

Nkhskt. Angie Motshekga,
iNdvuna yeMfundvo yeSisekelo.



UMnu Enver Surty, Liphini
leNdvuna yeMfundvo
yeSisekelo.

Letincwadzi tekusebentela tikhicitelwe bantfwana baseNingizimu Afrika ngekuholwa yiNdvuna yeTemfundvo yeSisekelo, Nkhskt Angie Motshekga akanye neLiphini lakhe uMnu Enver Surty.

LeTincwadzi Tekusebentela takaRainbow tiyincenye yemitamo yaleLitiko leTemfundvo yeSisekelo yekutfutfukisa bafundzi baseNingizimu Afrika emabangeni ekucala lasitfupha ekufundza. Njengalomunye wemigomo lehamba embili eLuhlelweni lweKusebenta lwaHulumende, lomsebenti ukhokhelwe ngesihle Silulu seTimali saVelonkhe. Ngenca yalokusekelwa ngetimali, leLitiko leTemfundvo liphumelele kwakha letincwadzi ngato tonkhe letilwimi letisemtsetfweni kulelive.

Siyetsemba kutsi bothishela batatitfola tilusito kakhulu letincwadzi tekusebentela basafundzisa malanga onkhe kute bafundzi bakhone kucedza luhlelo lwabo lwekufundza. Setame, ngekucophelela lokukhulu, kusita thishela kuleyo naleyo ncenye yemsebenti, ngekusebentisa timphawu letitifombe kukhombisa umfundzi loko lokumele akwente.

Siyetsemba bantfwana nabo batakujabulela kusebentisa letincwadzi basachubeka nekukhula nekufundza; nekutsi bothishela batawutfokota kanye nabo.

Sifisela bothishela nebafundzi imphumelelo basachubeka nekusebentisa letincwadzi tekusebentela.





MATHEMATICS IN SISWATI
GRADE 2 – BOOK 1
TERMS 1 & 2
ISBN 978-1-4315-0001-7

THIS BOOK MAY NOT BE SOLED.

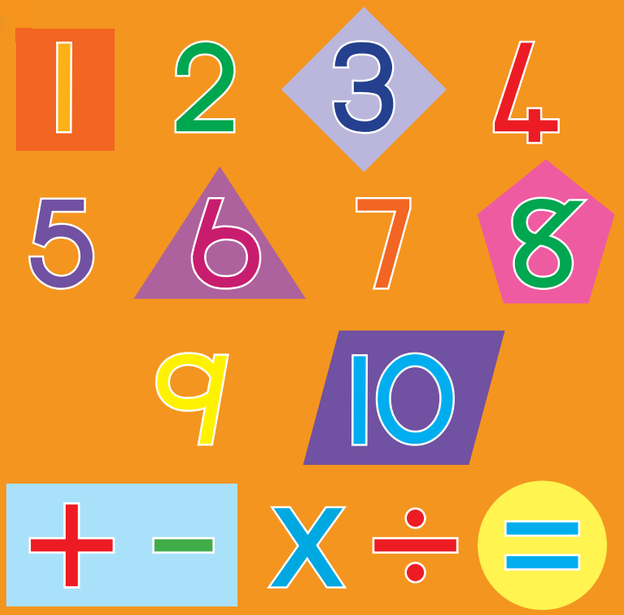

ISBN 978-1-4315-0001-7

TIBALO NGESISWATI – Libanga 2 Incwadzi I



TIBALO NGESISWATI

Libanga 2

Ligama:

Likilasi:

basic education
Department:
Basic Education
REPUBLIC OF SOUTH AFRICA

Incwadzi I
Emathemu
1 & 2

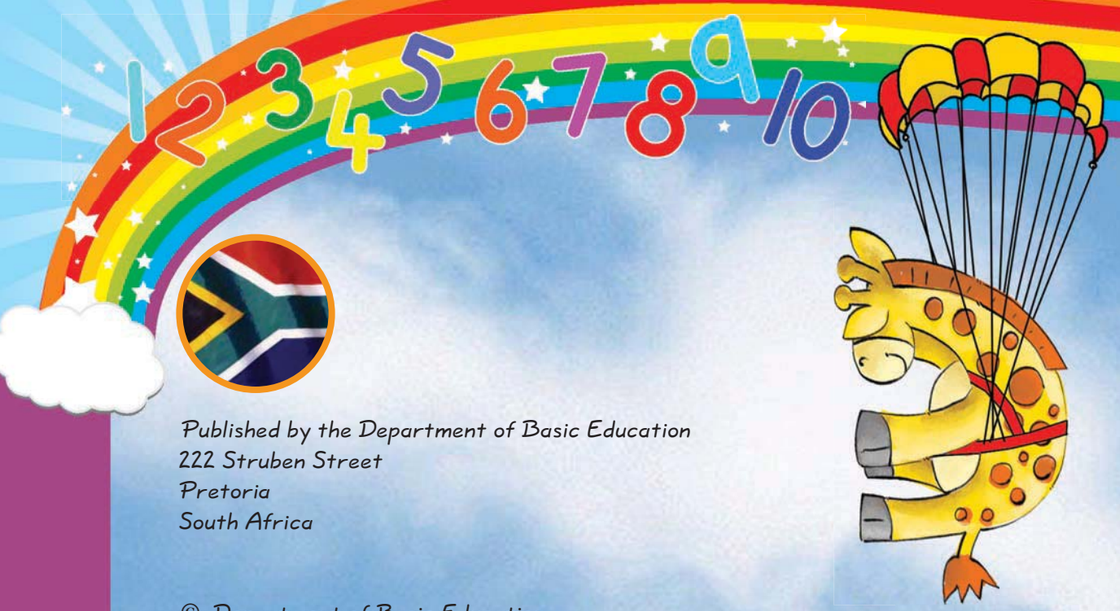

Published by the Department of Basic Education
222 Struben Street
Pretoria
South Africa

© Department of Basic Education
Third edition 2013

ISBN 978-1-4315-0001-7

The Department of Basic Education has made every effort to trace copyright holders but if any have been inadvertently overlooked, the Department will be pleased to make the necessary arrangements at the first opportunity.

This book may not be sold.



basic education
Department:
Basic Education
REPUBLIC OF SOUTH AFRICA

1 – 100

1	2	3	4	5	6	7	8	9	10
11	12	13	14	15	16	17	18	19	20
21	22	23	24	25	26	27	28	29	30
31	32	33	34	35	36	37	38	39	40
41	42	43	44	45	46	47	48	49	50
51	52	53	54	55	56	57	58	59	60
61	62	63	64	65	66	67	68	69	70
71	72	73	74	75	76	77	78	79	80
81	82	83	84	85	86	87	88	89	90
91	92	93	94	95	96	97	98	99	100

1 2 3 4 5 6 7 8 9 10 11 12 13 14 15 16 17 18 19 20 21 22 23 24 25 26 27 28 29 30 31 32 33 34 35 36 37 38 39

Libanga 2

Rainbow WORKBOOKS

Tibalo

ngeSISWATI

Lencwadzi ya:



SISWATI

Incwadzi 1

I

Lusuku: _____

Mine nemndeni wami





Gcwalisa timphendvulo kulemibuto ngawe nangemndeni wakho.

Ligama lami ngu_____ .

Ngineminyaka lengu _____ .

Eminyakeni lemibili leyendlulile benginemiyaka lengu_____ .

Emnyakeni lotako ngitawuba neminyaka lengu_____ .

Ngihlala e_____ .

Ngubani lomdzala emndenini wakho?_____

Bhala phasi kutsi uneminyaka lemingakhi. _____

Ngubani lomncane emndenini wakini?_____

Bhala phasi kutsi uneminyaka lemingakhi _____ .

Namuhla ngumhlaka_____ .

1 2 3 4 5 6 7 8 9 10



Dvweba sitfombe semndeni wakho.



1 2 3 4 5 6 7 8 9

Teacher:

Sign:

Date:



11 12 13 14 15 16 17 18 19 20

2

Lusuku:

Kubala



Gcwalisa tikhala letingenalutfo.



Emehlo		2
Emacashata	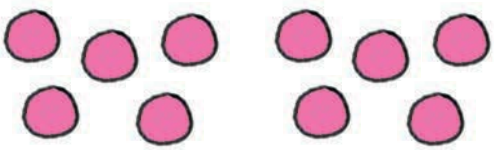	
Ticeshana		



Emehlo		
Emacashata		
Ticeshana		

1 2 3 4 5 6 7 8 9 10





Emehlo

Emacashata

Ticeshana



Emehlo

Emacashata

Ticeshana



Yaba lamacashata neticeshana ngalokulinganako.

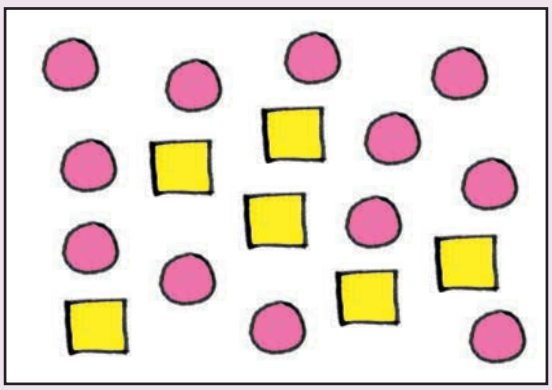







11 12 13 14 15 16 17 18 19 20

Teacher:

Sign:

Date:

Lusuku: _____

Tinombolo



Fundza letimphawu tetinombolo kanye nemagama ebhodini.

1 73 59 66 35 42 97 24 32

imfica

lishumi nakunye

lishumi nakune

sitfupha

lishumi nesikhombisa

kune

lishumi

lishumi nemfica



Bhala linani lemabhaluni esibayeni.

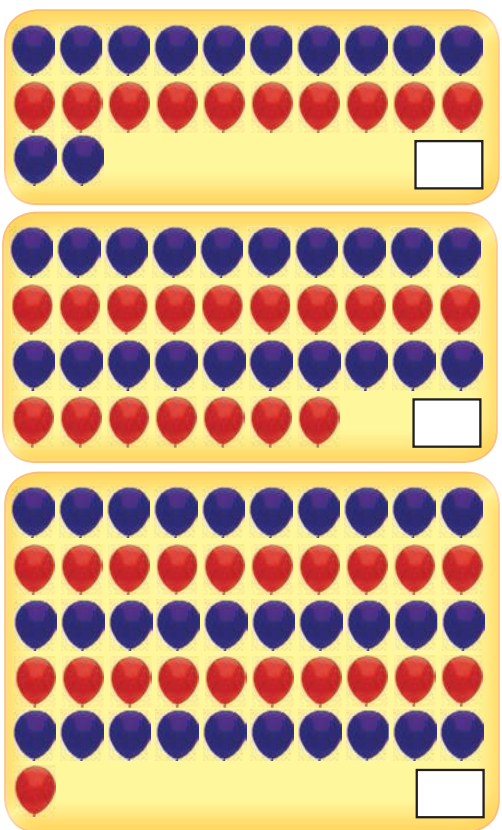

1 2 3 4 5 6 7 8 9 10



Bhala letinombolo letilandzelako ngemagama.

6		12	
4		17	
8		14	
1		22	
2		18	
5		11	
0		20	
10		15	
3		13	
9		16	

37 38 39 40 41 42 43 44

89 90 91 92 93 94 95 96 97

Teacher:

Sign:

Date:

11 12 13 14 15 16 17 18 19 20

Lusuku:

Tinombolo





Dweba △ kutinombolo leticondzile na ◯ kutinombolo lugweje.

leticondzile

lugweje

1	2	3	4	5	6	7	8	9	10
11	12	13	14	15	16	17	18	19	20



Faka tinombolo kuletindlu.





Bala lemibala lemibili yebuhlalu.

Bhala inombolo yelinani ngalinye.

10	2	=	12
10	3	=	
10	5	=	
10	8	=	
10	9	=	

Singayibhala kanje.

10 + 2 = 12

□ + □ = □

□ + □ = □

□ + □ = □

□ + □ = □



Itsini imphendvulo?

10 + 1 = □	10 + 9 = □	10 + 6 = □
10 + 8 = □	10 + 2 = □	10 + 3 = □
10 + 5 = □	10 + 4 = □	10 + 7 = □



1 3 5 7 9 11 13 15 17 19

2 4 6 8 10 12 14 16 18 20

Teacher:

Sign:

Date:

11 12 13 14 15 16 17 18 19 20

Lusuku: _____

Kuhlanganisa nekususa





Hlanganisa uphindze ususe.



9 + 8 = 17



18 – 8 = ☐



☐ + ☐ = ☐



☐ + ☐ = ☐



☐ + ☐ = ☐



Bala.

6 + 5 = ☐	8 + 9 = ☐	11 + 3 = ☐	12 – 5 = ☐
8 + 7 = ☐	3 + 8 = ☐	9 – 5 = ☐	16 – 9 = ☐
6 + 4 = ☐	8 + 4 = ☐	8 – 4 = ☐	6 – 4 = ☐







Hlanganisa.

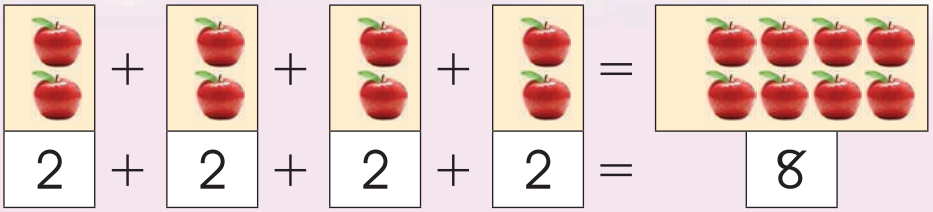

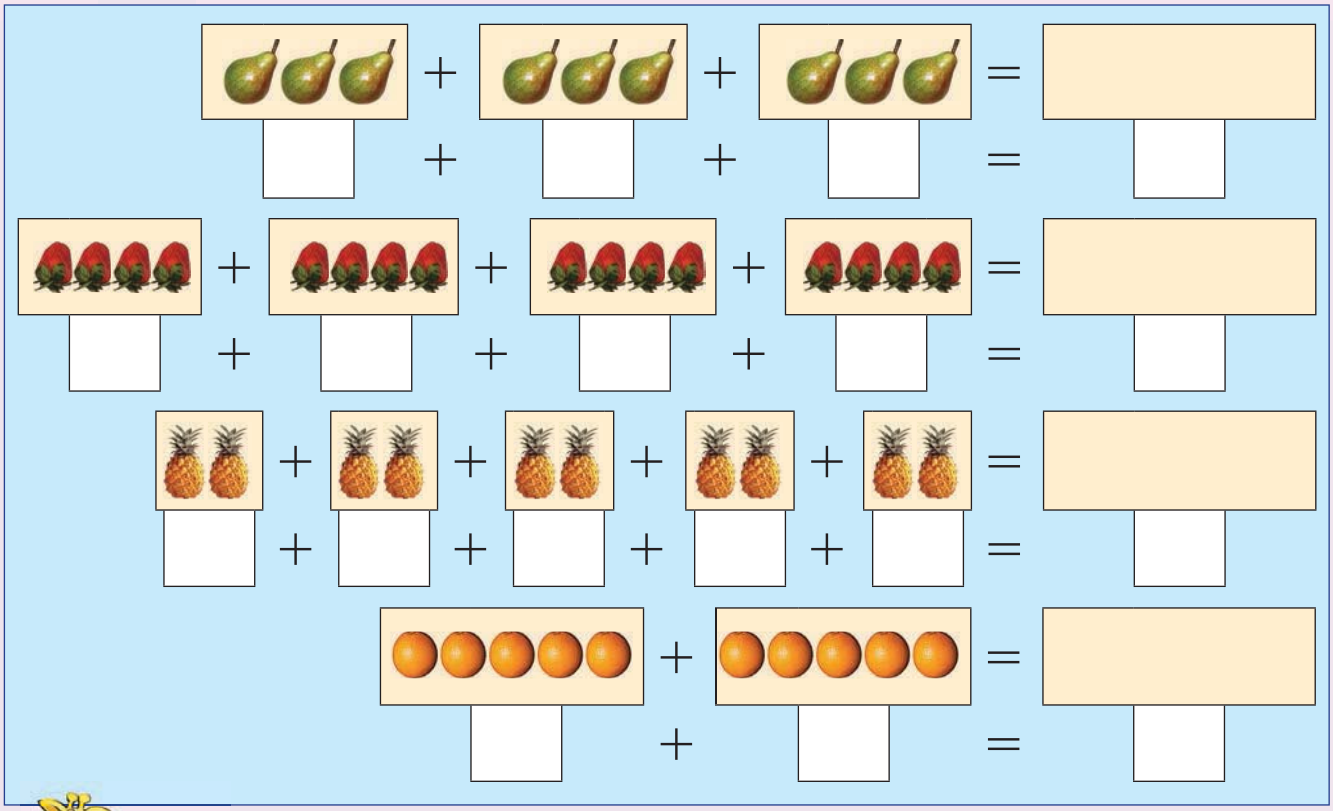



Bala.

2 + 2 + 2 = ☐	1 + 1 + 1 + 1 + 1 + 1 = ☐	2 + 2 + 2 + 2 = ☐
4 + 4 = ☐	3 + 3 + 3 + 3 = ☐	4 + 4 + 4 + 4 = ☐
5 + 5 + 5 = ☐	5 + 5 = ☐	1 + 1 + 1 = ☐





2 + 2 + 2 + 2 + 2 + 2

Teacher:

Sign:

Date:



11 12 13 14 15 16 17 18 19 20

Lusuku:

Kwabelana nemali



Yaba letitselo ngaphasi.

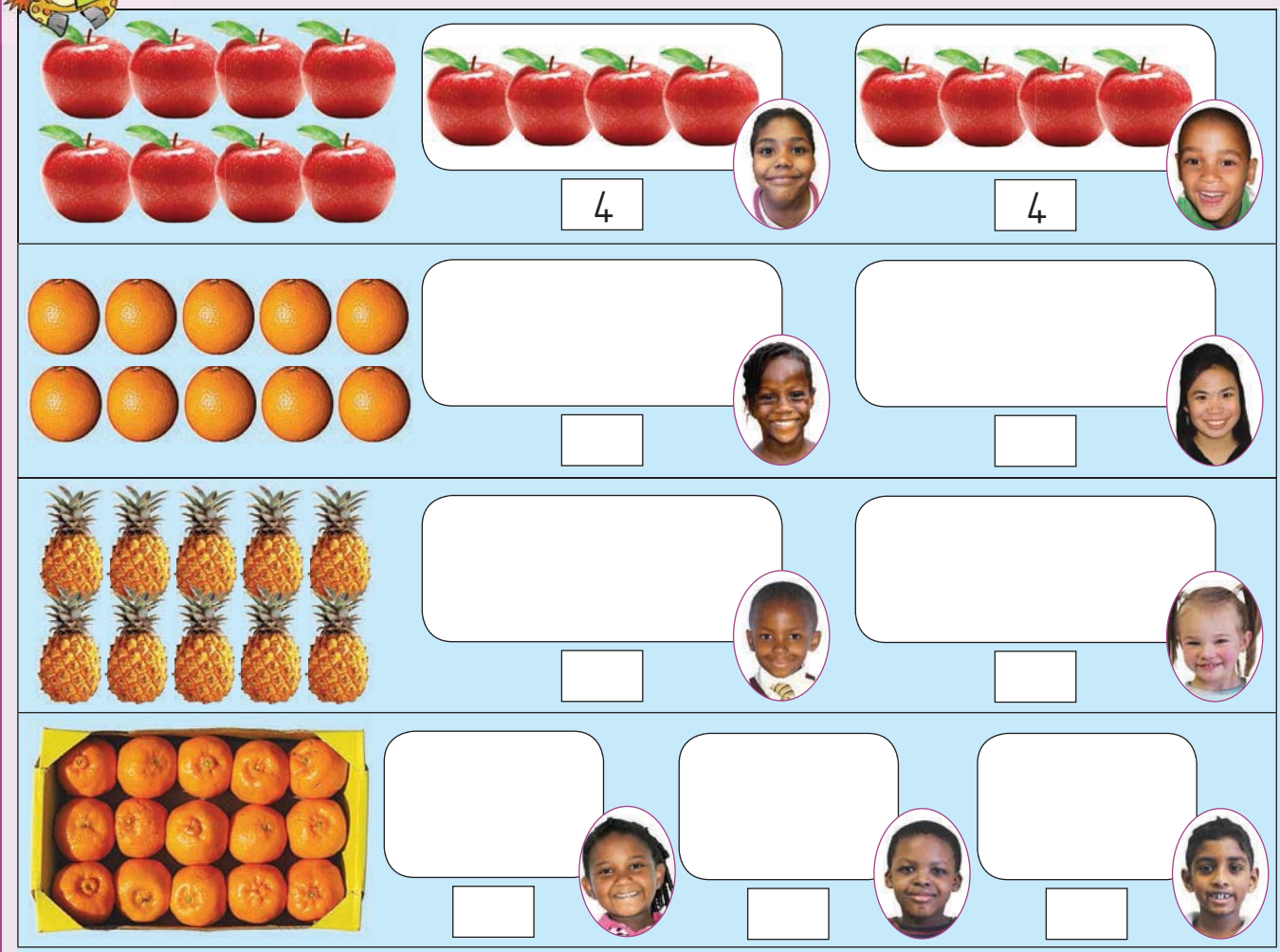







Cedzela.








senti munye					









Faka umbala kutindibilishi letenta linani lelifanako nalelisekucaleni.



10c	10c	5c	2c	1c	2c



5c	2c	2c	1c	2c	2c



R2	R2	R1	R1	R1



= R5 R2 R1 R5 R1 R2



= R2 R2 R5 R5 R2 R1 R5



R1 1c R5 5c R10

Teacher:
Sign:
Date:



Lusuku:

Emaphethini

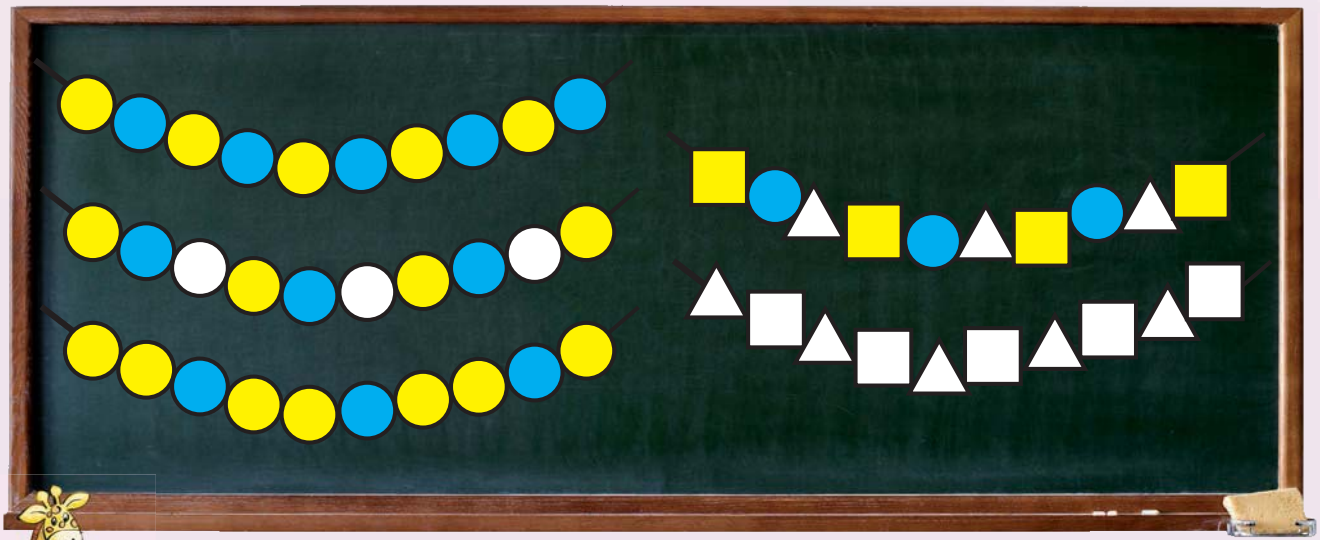



Kopa lamaphethini lasebhodini.

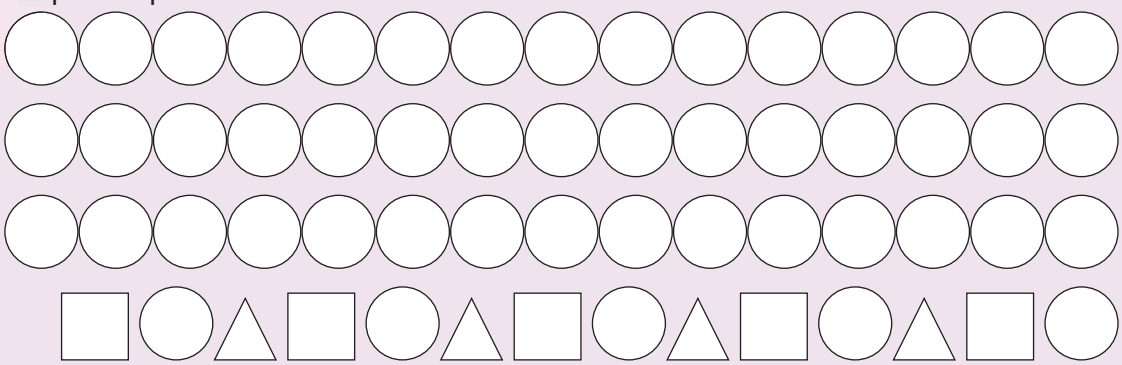



Khulisa lephethini.



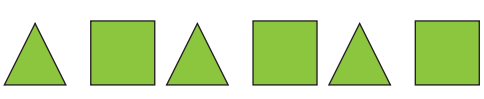



Faka umbala kulobuhlalu ngalesikhatsi ubala ngakubili.

2	4	6							

Faka umbala kuletibaya ngalesikhatsi ubala ngakuhlanu.

5	10	15							

Faka umbala kulobuhlalu ngalesikhatsi ubala ngemashumi.

10	20	30							

OLIAOLIAOLIA

Teacher:
Sign:
Date:

11 12 13 14 15 16 17 18 19 20

Lusuku:

Bobunjwa



Faka umbala lolingangane kulocalandze, letindilinga tibe bovu bese kutsi bocalantsatfu babe liphuti.

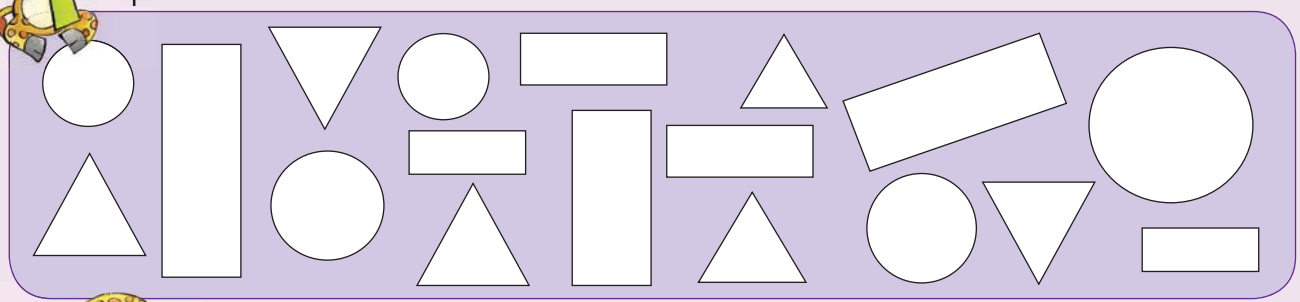

Faka umbala lobovu kuto tonkhe tindilinga letinkhulu, bocalandze babe lingangane kantsi bocalantsatfu labancane babe liphuti.

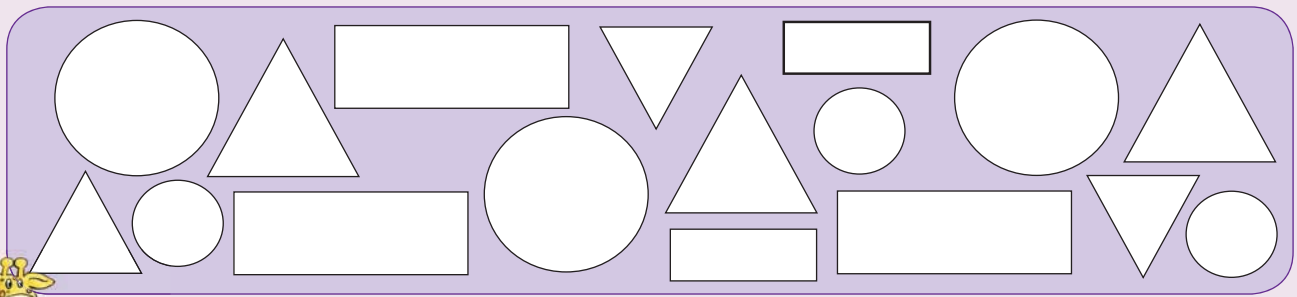

Faka umbala kumphendvulo leliciniso.



kucondzile | yindilinga



kucondzile | yindilinga



kucondzile | yindilinga

Dvweba kulamanye emacala emavivane.



Teacher:

Sign:

Date:

Lusuku:

Emabhola nemabhokisi







Kipilitela emabhokisi ngembala loluhlata sasibhakabhaka bese emabhola kuba ngulobovu.





Faka umbala emphendvulweni leliciniso.



Libhokisi | liyashelela | liyagicika



Ibhola | iyashelela | iyagicika



Faka umbala kumphendvulo leliciniso.



umphetfo loyindilinga

umphetfo locondzile



umphetfo loyindilinga

umphetfo locondzile



umphetfo loyindilinga

umphetfo locondzile



umphetfo loyindilinga

umphetfo locondzile



umphetfo loyindilinga

umphetfo locondzile



umphetfo loyindilinga

umphetfo locondzile



umphetfo loyindilinga

umphetfo locondzile



umphetfo loyindilinga

umphetfo locondzile

Shano kutsi ibhola ingemuva, ingaphambili, isedvute ne nobe ingetulu kwelibhokisi.



phambili | ngemuva

ngetulu | edvute ne



phambili | ngemuva

ngetulu | edvute ne



phambili | ngemuva

ngetulu | edvute ne



phambili | ngemuva

ngetulu | edvute ne



ibhola libhokisi

Teacher:

Sign:

Date:

Lusuku:

Budze





Ngusiphi sitimela lesifisha nobe lesidze?





sifisha | sidze



sifisha | sidze



Ngusiphi sakhiwo lesiphakeme nobe lesiphasi?

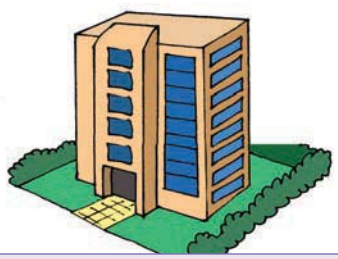

siphakeme

siphasi



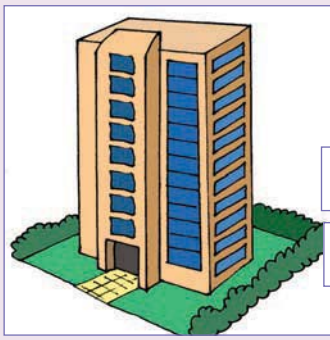

siphakeme

siphasi



Ngumuphi umuntfu lomfisha nobe lomudze?



Mfisha	Mfisha
Mudze	Mudze

Sebentisa lomfanekiso wesandla. Tingakhi tandla letindze kulocalandze?
Sebentisa lomfanekiso welunyawo. Ngabe localandze mudze ngetinyawo letingaki?







Nyalo linganisa lokuya etulu kwacalandze ngetandla nangetinyawo.









Teacher:
Sign:
Date:



11 12 13 14 15 16 17 18 19 20

II

Lusuku:

Sisindvo





Shano kutsi lentfo iyesindza nobe imalula.



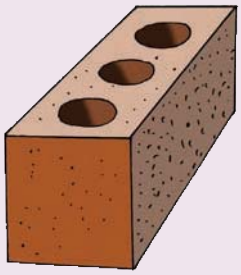

iyesindza	imalula	iyesindza	imalula



Kipilitela intfo leyesindzako.









1 2 3 4 5 6 7 8 9 10





Ngabe lentfo yesindza ngetulu nobe ngaphasi kwelikhilogramu linye?



iyesindza | imalula



iyesindza | imalula



iyesindza | imalula



iyesindza | imalula



iyesindza imalula

Teacher:

Sign:

Date:



11 12 13 14 15 16 17 18 19 20

Lusuku:

Umtsamo



Faka umbala emphendvulweni leliciniso.



ligcwele	alinalutfo	liyihhafu



ligcwele	alinalutfo	liyihhafu



ligcwele	alinalutfo	liyihhafu



ligcwele	alinalutfo	liyihhafu

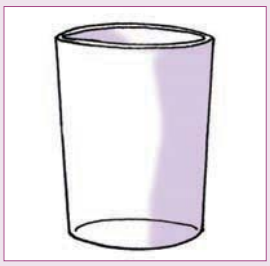

ligcwele	alinalutfo	liyihhafu

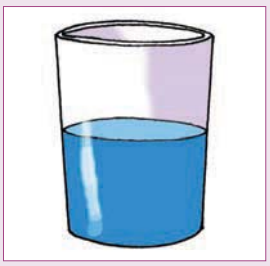

ligcwele	alinalutfo	liyihhafu





Sikali sinye sigcwalisa sifike kumugca wekucala kulelijeke.
Tingakhi tikali letitawugcwalisa lelijeke?





Tingakhi tikali letitselwa kulamajeke?

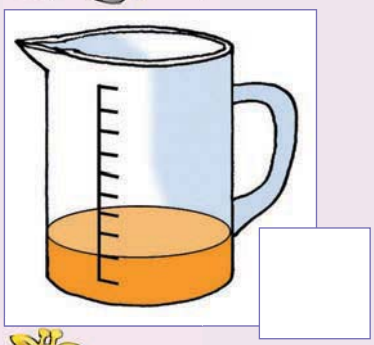

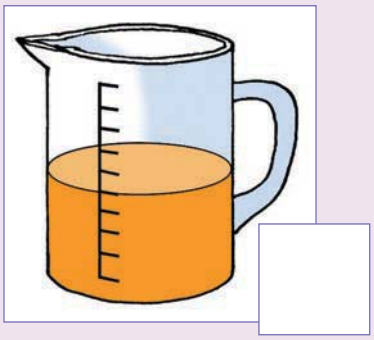

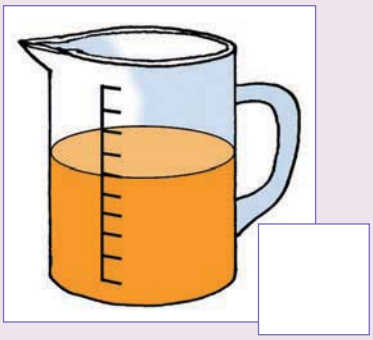



Lijeke lelingesancele libamba I litha wemanti.
Nguliphi lijeke lelinejusi lelinganako futsi nguliphi lelinejusi lencane?



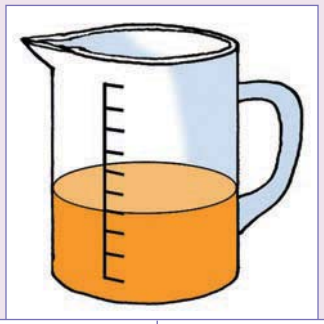

lelinganako | lencane



lelinganako | lencane



ligcwele alindlutfo

Teacher:
Sign:
Date:



11 12 13 14 15 16 17 18 19 20

Lusuku:

Sikhatsi

1 Juba lamagama bese uwanamatsisela ngaphasi kwetitfombe.
Sebentisa labobunjwa kuLokujutjiwe 2.



2 Cedzela lemisho.

Ngi_____ ekuseni kakhulu.

Ngi _____ekuseni.

Ngi_____emini.

Ngi_____ onkhe malanga.

Ngi_____ kamuva onkhe malanga.

1 2 3 4 5 6 7 8 9 10



Itolo	Namuhla	Kusasa
		



Phendvula lemibuto.

Wentani umntfwana namuhla? _____

Yini leyentiwe ngumntfwana itolo? _____

Yini letawentiwa ngumntfwana kusasa? _____



Dvweba sitfombe sakho.

Itolo	Namuhla	Kusasa



itolo kusasa



Teacher:

Sign:

Date:



11 12 13 14 15 16 17 18 19 20

Lusuku:

Ikhalenda Yetinsuku Tekutalwa



Landzelela letinyanga.

Bhimbidvwane
Sipho
Maryke
Annie

iNdlovana
Jeffrey
Simon

iNdlovulenkhulu
Sam
Juan

Mabasa
Betty
Liezel

iNkhwekhweti
Lettie
Ricco
George

iNhlaba
Mpho

Kholwane
Palesa
Lisa
Kayla

iNgci
Mbali
Brenda
Mary

iNyoni
John

iMphala
Karin
Jaco

Lweti
Gugu
Dian

iNgongoni
Kara
Richard
Denise

1 2 3 4 5 6 7 8 9 10



Bhala ligama lemntfwana ngamunye kukhalenda yetinsuku tekutalwa.

Bhimbidvwane	iNdlovana	iNdlovulenkhulu
Mabasa	iNkhwekhweti	iNhlaba
Kholwane	iNgci	iNyoni
iMphala	Lweti	iNgongoni



Lusuku lwami lwekutalwa

Teacher:

Sign:

Date:



Lusuku:

Gcogca uphindze uhlunge

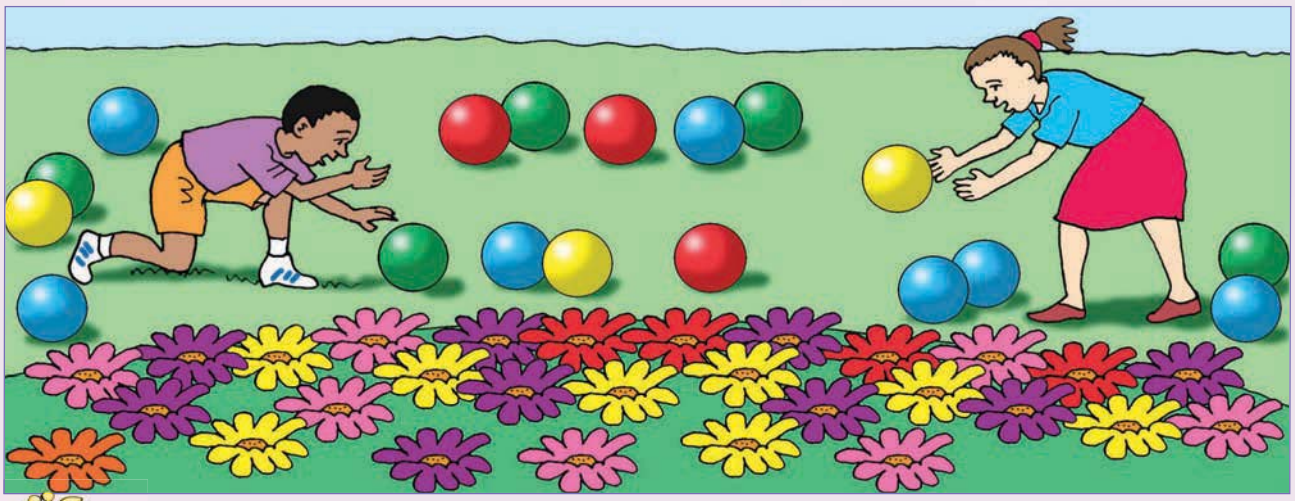



Gcogca uphindze uhlunge emabhola bese uwadvweba ebhokisini lelifanele.

Emabhola laluhlata | Emabhola lamtfubi | Emabhola lalingangane | Emabhola laliphuti



Gcogca timbali bese uyatihlunga.



Timbali letimtfubi | Timbali letibovu | Timbali letisamsobo | Timbali letiphinki | Timbali letiliphuti

1 2 3 4 5 6 7 8 9 10

Hlunga letintfo. Yenta imidvwebo yakho.



tintfo letilula

tintfo letisindzako



emabhola lamancane

emabhola lamakhulu

emabhokisi lamancane

emabhokisi lamakhulu

Teacher:

Sign:

Date:

11 12 13 14 15 16 17 18 19 20

Lusuku:

Fundza uphindze uhumushe



Umdvwebo wami





Hlukanisa emakhrayoni. Yenta umdvwebo wawo.





Hlukanisa timbali. Yenta umdvwebo wato.





Hlukanisa lamafu nalemishi-yenkhosatana. Yenta umdvwebo wako.





Phendvula lemibuto.

		
bocalantsatfu	bocalandze	tindilinga

Bangakhi bocalantsatfu labalapho? ☐

Bangakhi bocalandze labalapho? ☐

Tingakhi tindilinga letilapho? ☐

Ngabe kunabocalantsatfu labanyenti nobe bocalandze? _____

Ngabe kunetindilinga letinyenti nobe bocalantsatfu? _____

Ngabe kunetindilinga letinyenti nobe bocalandze? _____

		
akunalutfo	yihhafu	kugcwele

Mangakhi emajeke langenalutfo lakhona? ☐

Mangakhi emajeke lagcwele kancane? ☐

Mangakhi emajeke lagcwele? ☐



Teacher:
Sign:
Date:

11 12 13 14 15 16 17 18 19 20

Lusuku: _____

Ngembili, emkhatsini nasemuva

Chaza tinombolo ngekusebentisa emagama ngembili, emkhatsini nasemuva.

1	2	3	4	5	6	7	8	9	10	11	12	13	14	15	16	17	18	19	20	21	22	23	24	25

Sibonelo: Nguleyobhola lebovu isemkhatsini wemabhola lamabili lalingangane.

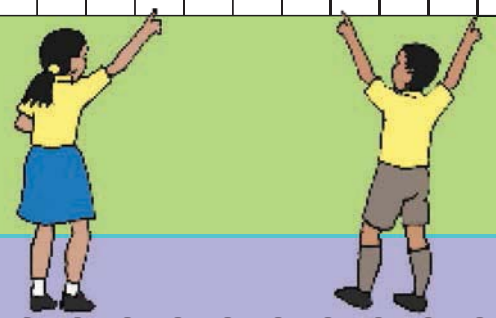





Bhala inombolo lefanele kusikwele.

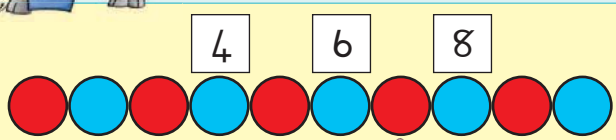

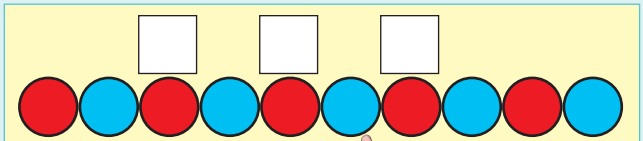

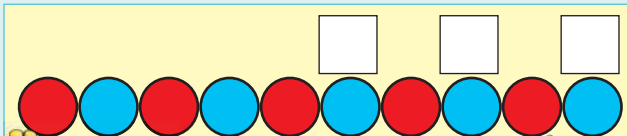

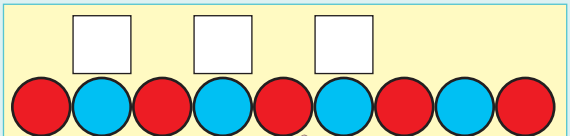



Gcwalisa tinombolo letingekho.

	2			5	
	12			15	
13			16		

10			13		
	17			20	
20					25

1 2 3 4 5 6 7 8 9 10 11 12 13 14 15 16 17 18 19 20 21 22 23 24 25

Nguyiphi inombolo lesembi kwa 8? _____

Nguyiphi inombolo lesemuva kwa 16? _____

Ngutiphi tinombolo letisemkhatsini wa 8 na 12? _____





Faka umbala lolingangane kutinombolo letisemkhatsini wa 14 na 17. Faka umbala lobovu kunombolo lesembi kwa 14 na 17. Faka umbala lomtfubi ngemuva kwa 17.

11	12	13	14	15	16	17	18	19	20

11 12 13 14 15 16 17 18 19 20 21 22 23 24 25 26 27 28 29 30

Bhala tonkhe letinombolo etukwe buhlalu lobumtfubi.
Sitibita ngani letinombolo letikubuhlalu lobuphinki?

_____

Bhala tonkhe letinombolo etukwebuhlalu lobuphinki.
Sitibita ngani letinombolo letikubuhlalu lobuphinki?

_____

1 2 3 4 5 6 7 8 9 10 11 12 13 14 15 16 17 18 19 20



Yaba lobuhlalu lobuliphuti emkhatsini kwebantfwana labagcoke umbala loliphuti.

Ngabe munye utfola bungaki buhlalu? _____ . Ngabe bukhona lobusele? _____ .

Yaba buhlalu lobuphinki emkhatsini kwebantfwana labagcoke lokupinki.

Ngabe munye utfola bungakhi buhlalu? _____ . Ngabe bukhona lobusele? _____ .

Phendvula lemibuto lelandzelako.

Ngumuphi nombololingana lota nje ngemuva kwa 12? _____

Ngumuphi nombololugweje lota nje ngemuva kwa 14? _____

Ngutiphi tinombololugweje letita emkhatsini kwa 10 na 16? _____

Bhala phasi tinombololugweje emkhatsini kwa 8 na 18? _____

Teacher:

Sign:

Date:



Lusuku:

Tinombolo 1–30

Ubala emabhuku lamangakhi?
Ubala emajeke apende lamangakhi?



1 Bungakhi buhlalu lobubalako?

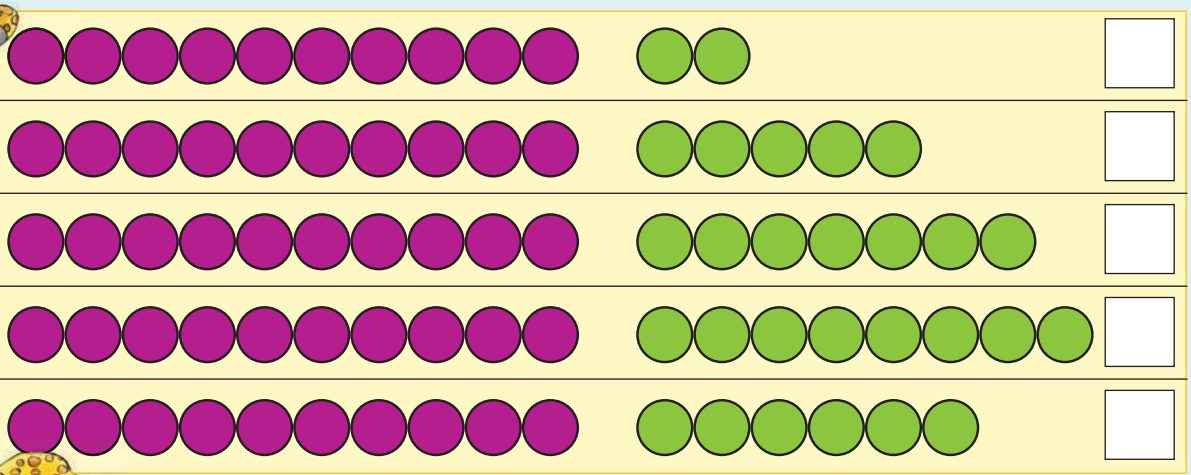

2 Mangakhi emabhuku lowabalako?



3 Gcwalisa inombolo lengekho.

14	12	15	17	19	13	26	28	21	30
10 4	2	10	7	10					

1 2 3 4 5 6 7 8 9 10



Buka sibonelo sekucala bese ucedzela konkhe lokulandzelako.

18	=	1	lishumi	+	8	emayunithi	nobe	18	=	10	+	8
15	=		lishumi	+		emayunithi	nobe		=		+	
19	=		lishumi	+		emayunithi	nobe		=		+	
22	=		lishumi	+		emayunithi	nobe		=		+	
24	=		lishumi	+		emayunithi	nobe		=		+	

Bungakhi buhlalu lobubalako?

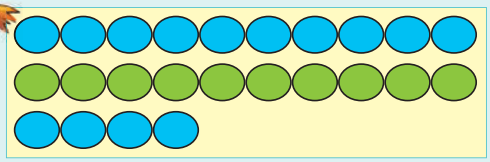

Inombolo

Singayibhala njenga: 20 + ☐ = 24

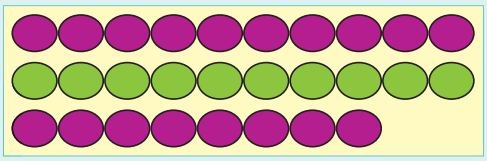

Inombolo

Singayibhala njenga: 20 + ☐ = 28

Bhala emagama aletinombolo:

10	_____	11	_____
12	_____	13	_____
14	_____	15	_____
16	_____	17	_____
18	_____	19	_____
20	_____	21	_____
22	_____	23	_____
24	_____	25	_____

Buka sibonelo sekucala bese ucedzela konkhe lokulandzelako.

25	=	2	lishumi	+	5	emayunithi		22	=	2	lishumi	+	2	emayunithi
13	=		lishumi	+		emayunithi		21	=		lishumi	+		emayunithi
26	=		lishumi	+		emayunithi		19	=		lishumi	+		emayunithi

Teacher:
Sign:
Date:



Lusuku:

Imigcanombolo



1 Gcwalisa tinombolo letingekho.

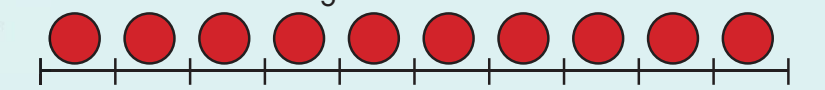

0	1			4						10

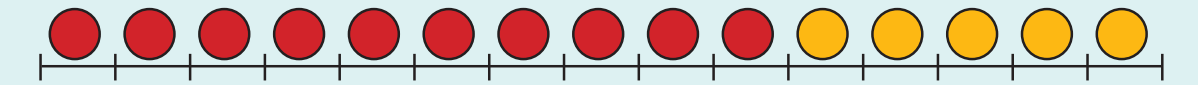

0					5	6								15

2 Ngabe logwaja uzube ngakanani? Sebentisa umugcanombolo kutfola timphendvulo.



0	1	2	3	4	5	6	7	8	9	10

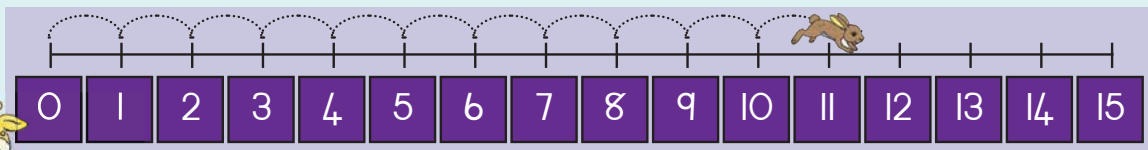

0	1	2	3	4	5	6	7	8	9	10	11	12	13	14	15

3 Ngabe imphala izube ngakanani? Sebentisa umugcanombolo kutfola timphendvulo.

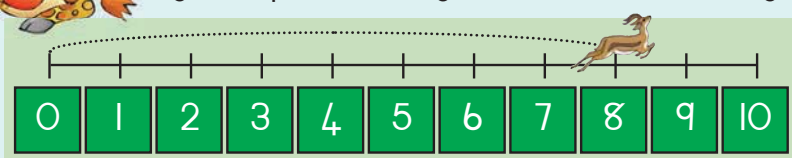

0	1	2	3	4	5	6	7	8	9	10

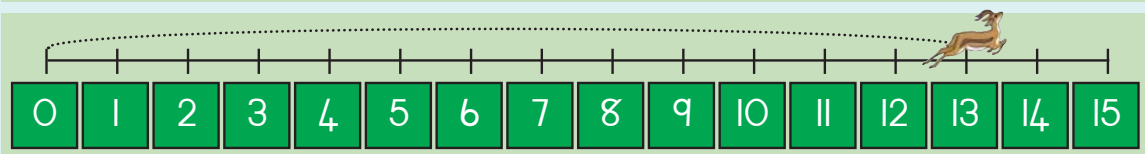

0	1	2	3	4	5	6	7	8	9	10	11	12	13	14	15



Cedzela lomugca nombolo. Ngabe logwaja uzube ngakanani?
Sebentisa umugcanombolo kutfola timphendvulo.

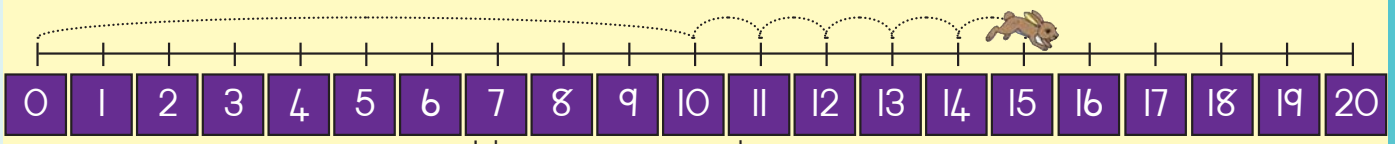

lishumi emayunithi

10 + 5 =

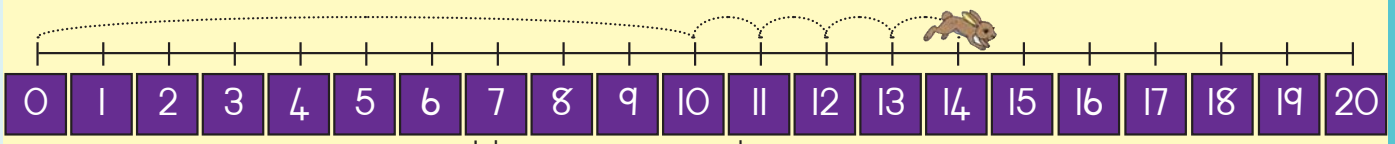

lishumi emayunithi

+ =

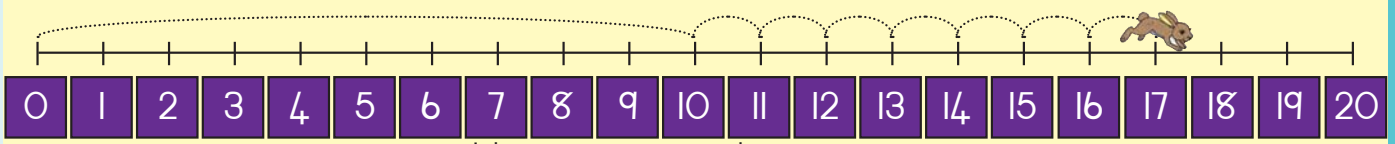

lishumi emayunithi

+ =

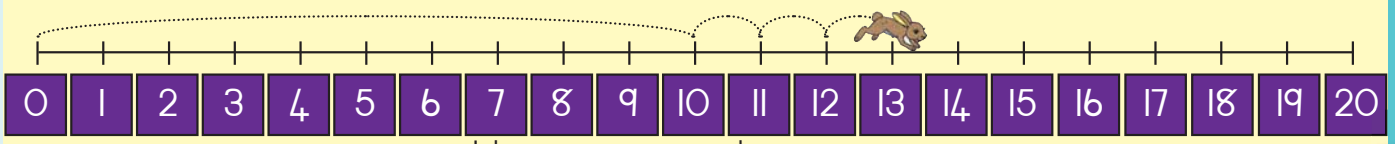

lishumi emayunithi

+ =

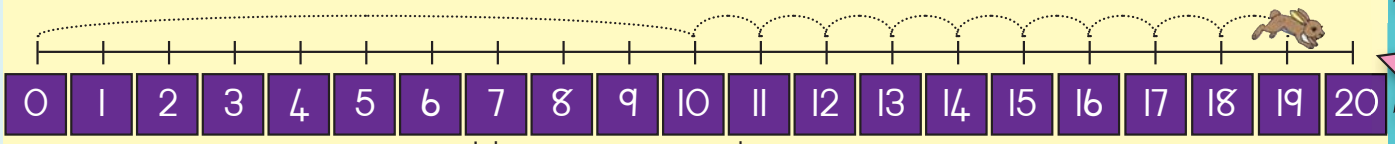

lishumi emayunithi

+ =

Teacher:
Sign:
Date:



Lusuku:

Imigcanombolo leyengetiwe





Sita logwaja kubhala sibalo. Sebentisa umugcanombolo kutfola timphendvulo.

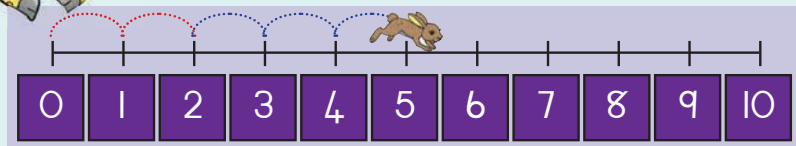

2 + 3 = 5

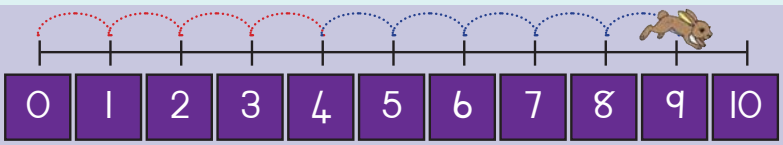

__ + __ = __



Sita imphala kubhala sibalo. Sebentisa umugcanombolo kutfola timphendvulo.

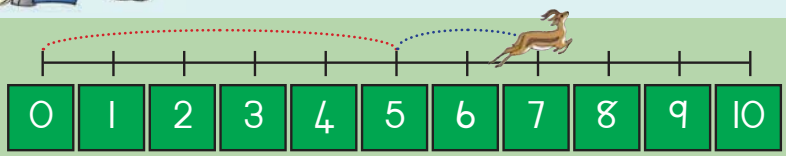

__ + __ = __

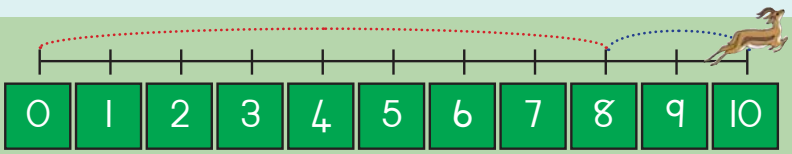

__ + __ = __







Sita logwaja kubhala sibalo. Sebentisa umugcanombolo kutfola timphendvulo.

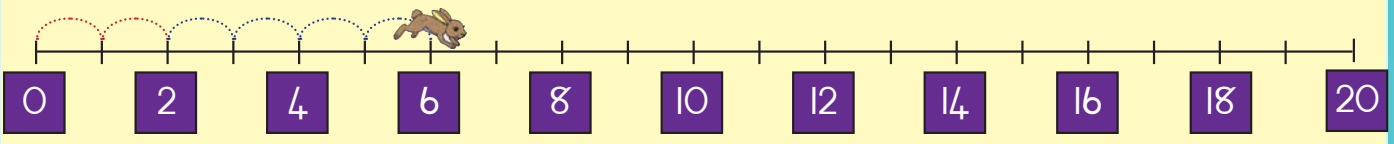

2 + 4 = 6

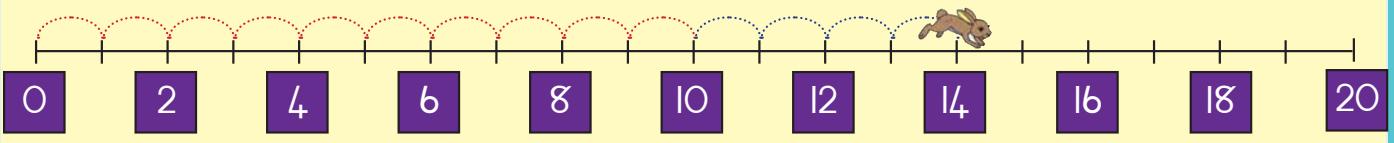

__ + __ = __



Sita imphala kubhala sibalo. Sebentisa umugcanombolo kutfola timphendvulo.

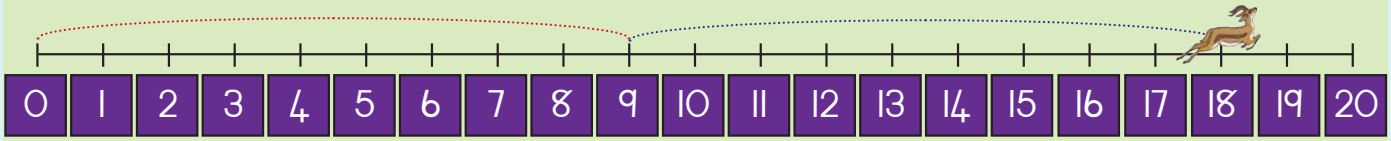

9 + 9 = __

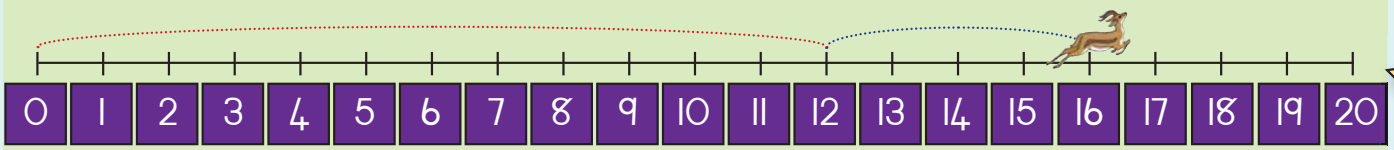

__ + __ = __



Teacher:

Sign:

Date:



Lusuku:

Kuhlanganisa nekususa

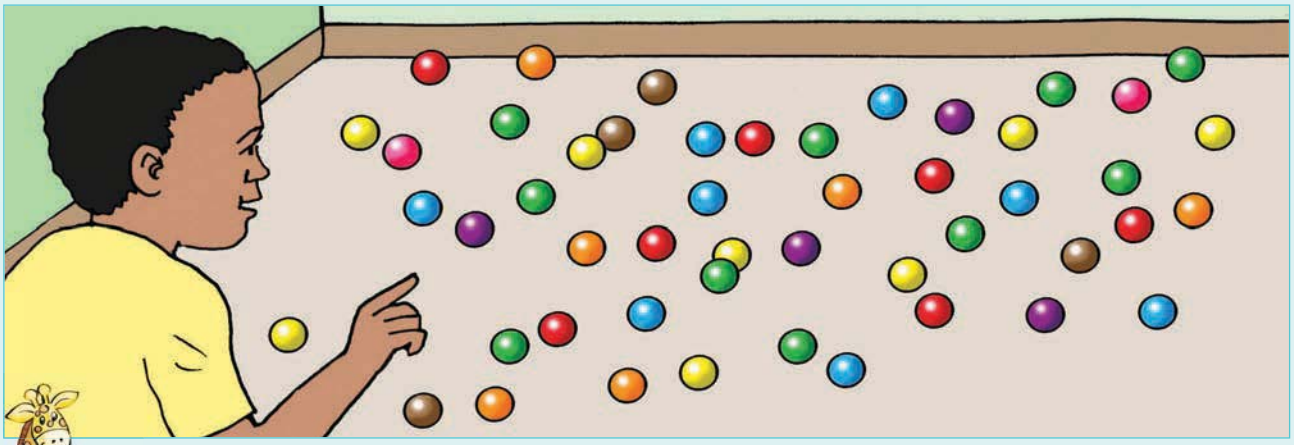



Bhala lelinani lebuhlalu.

Bungakhi buhlalu lobubovu lobulapho?

Bungakhi buhlalu lobuluhlata sasibhakabhaka lobulapho?

Bungakhi buhlalu lobuluhlata lobulapho?

Bungakhi buhlalu lobuliphuti lobulapho?

Bungakhi buhlalu lobusamsobo lobulapho?

Bungakhi buhlalu sebubonkhe?



Bhala lelinani lebuhlalu emabhokisini lekungiwo bese uyabuhlanganisa.

lobubovu	+	lobuluhlata	=	
lobumtfubi	+	lobuphinki	=	
lobuliphuti	+	lobulingangane	=	
lobusamsobo	+	lobuluhlata	=	
lobububendze	+	lobumtfubi	=	



Cedzela lamaphethini.





Sebentisa lobuhlalu kugcwalisa emabhokisi.

8	+	7	= 15
8	+ 2 +	5	=
9	+	6	=
9	+		+	=

Catsanisa lesitfombe nesibalo bese uniketa imphendvulo.

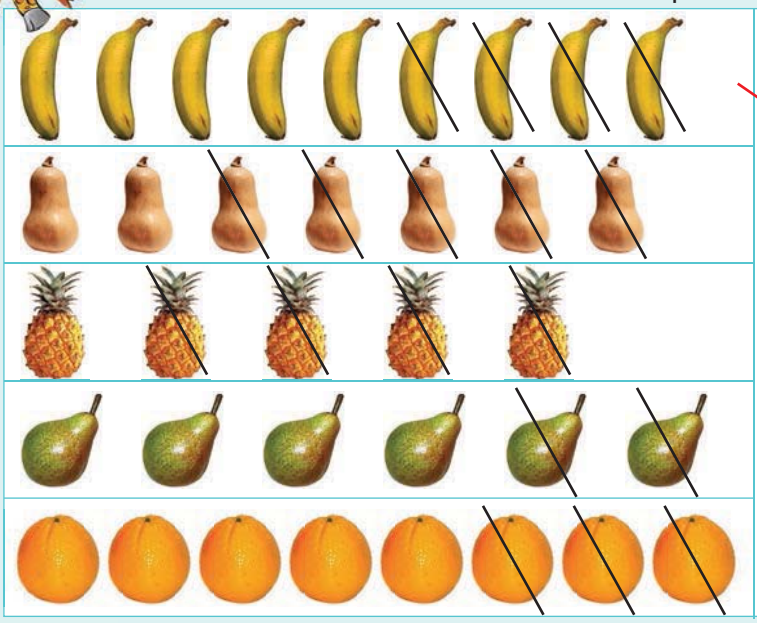

7 – 5 =	
9 – 4 =	
8 – 3 =	
5 – 4 =	
6 – 2 =	

Bhala sibalo saloku.

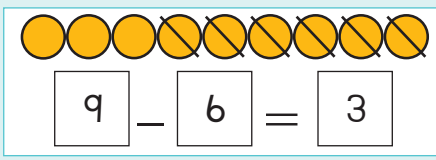

9 – 6 = 3

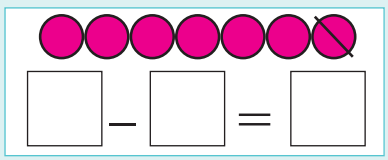

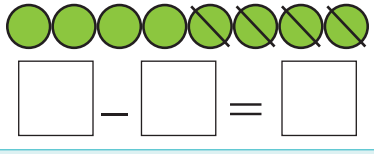

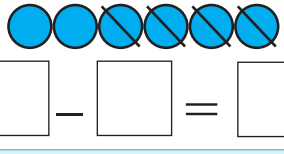

Teacher:
Sign:
Date:



Lusuku: _____

Emalanga, emaviki netinyanga

uMsombuluko

Lesibili

Lesitsatfu

Lesine

Lesihlanu

uMgcibelo

Lisontfo

Bhimbidvwane	iNdlovana	iNdlovulenkhulu
Mabasa	iNkhwenkweti	iNhlaba
Kholwane	iNgci	iNyoni
iMphala	Lweti	iNgongoni



Phendvula lemibuto lelandzelako ngemaviki.

Nguliphi lilanga lelita ngaphambi kwaLesitsatfu? _____

Nguliphi lilanga lelita ngemuva kwaLesitsatfu? _____

Nguliphi lilanga lelita ngemuva kweMgcibelo? _____

Nguliphi lilanga lelita emkhatsini kweMsombuluko naLesitsatfu? _____

Uma uMsombuluko ulilanga lekucala, Lesihlanu yena lilanga lesi _____

Nguwaphi emalanga leta emkhatsini kwaLesihlanu neMgcibelo.

_____



Phendvula lemibuto lelandzelako ngetinyanga.

Nguyiphi inyanga lefika ngaphambi kwaMabasa? _____

Nguyiphi inyanga leta ngemuva kweNhlaba? _____

Nguyiphi inyanga leta emkhatsini kweNgci neMphala? _____

Ngutiphi tinyanga letita emkhatsini kwaBhimbidvwane neNhlaba?

_____

Nguyiphi inyanga yekucala yemnyaka? _____

Nguyiphi inyanga yekugcina yemnyaka? _____



1 2 3 4 5 6 7 8 9 10



Tinkholo eNingizimu Afrika



Imicimbi yemlandvo

Lilanga lemalungelo ebantfu

Lilanga lenkhululeko

Lilanga lebasebenti

Lilanga lebantfu labasha

Lilanga labomake lavelonkhe

Lilanga lemagugu

Lilanga lekucolelana

Lusuku lwekutalwa

Lusuku Lwekutalwa lwami





Lokujutjwako 2: Sebentisa lokujutjiwe bese ukunamatsisela kukhalenda yetinyanga, emalanga etenkholo lamatsatfu kanye nemaholide esive aseNingizimu Afrika.

Bhimbidvwane	iNdlovana	iNdlovulenkhulu
Mabasa	iNkhwekhweti	iNhlaba
Kholwane	iNgci	iNyoni
iMphala	Lweti	iNgongoni



Teacher:

Sign:

Date:



Lusuku:

Kuhlanganisa



Buka kulesitfombe bese uhlanganisa lamamabuli.

labovu	+	lalingangane	=	3	+	4	=	
laluhlata	+	lalingangane	=		+		=	
lasamsobo	+	lalingangane	=		+		=	
laluhlata	+	laliphuti	=		+		=	
labovu	+	laluhlata	=		+		=	
laliphuti	+	lalingangane	=		+		=	

Hlanganisa.

3 + 2 =	4 + 6 =	9 + 3 =
6 + 5 =	7 + 8 =	8 + 4 =
9 + 5 =	8 + 6 =	7 + 4 =
9 + 9 =	7 + 5 =	8 + 8 =
7 + 6 =	9 + 6 =	7 + 7 =

Bhala sibalo saloku.

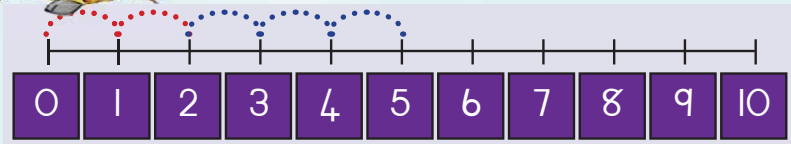

2 + 3 = 5

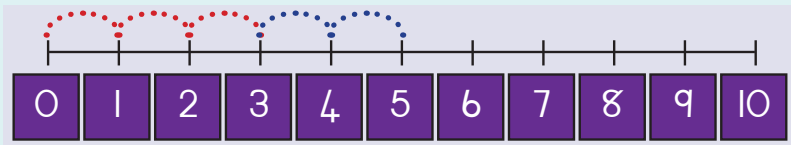

__ + __ = __

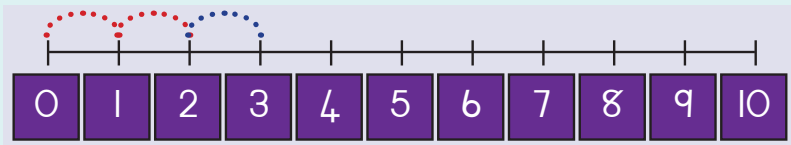

__ + __ = __



__ + __ = __

Linganisa letikalo. Kwekucala sesikwentele.

5 = 1 + 4

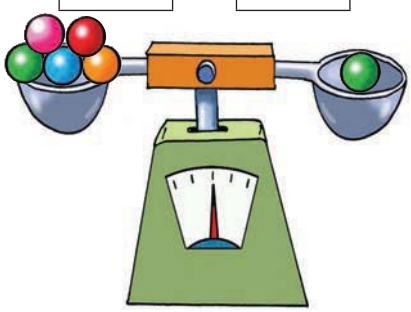

6 = 2 + __

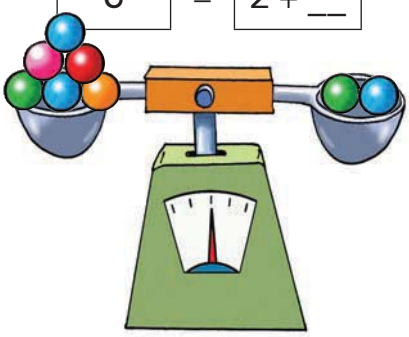

3 + __ = __

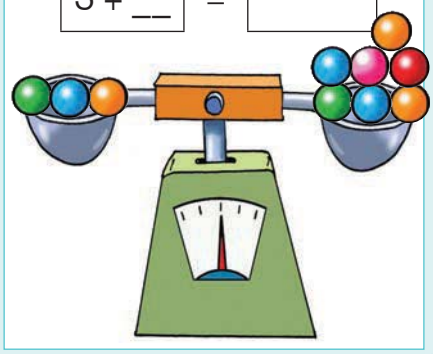

2 + 1 = 1 + __

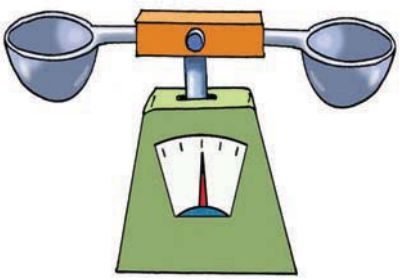

6 + 3 = 3 + __

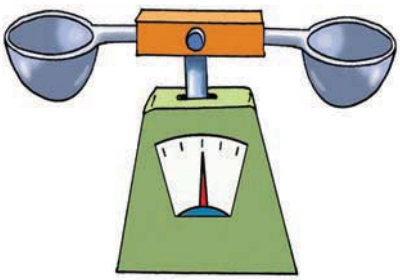

2 + __ = 8 + 2

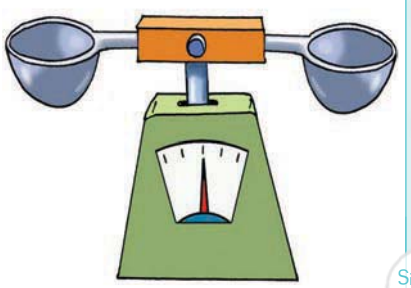

Teacher:

Sign:

Date:

23b

Lusuku:

Kususa

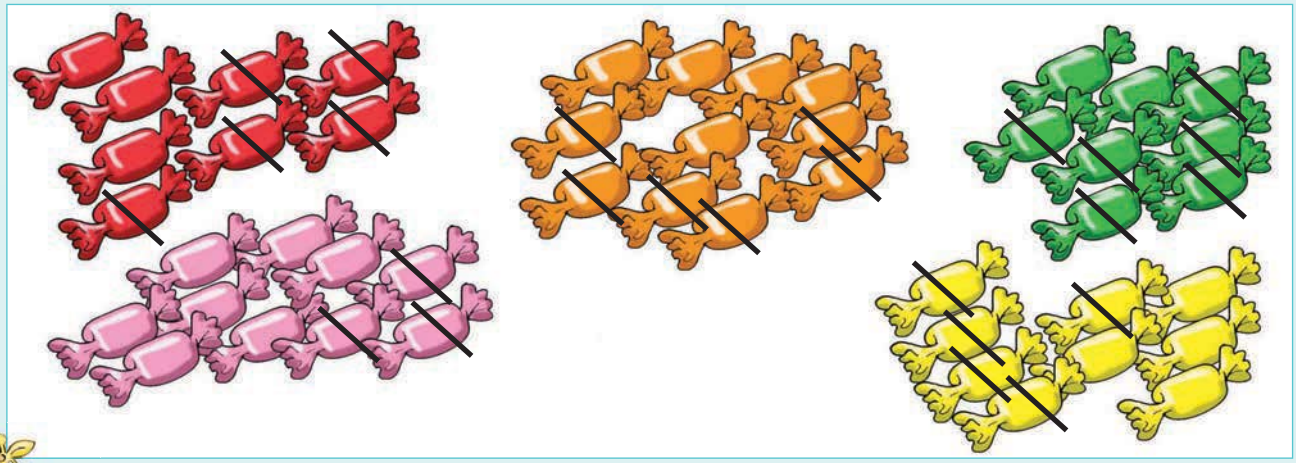



Buka kulesitfombe bese ubhala tibalo tekususa.

Emaswidi labovu	=	8	–	5	=	3
Emaswidi laluhlata	=		–		=	
Emaswidi lamtfubi	=		–		=	
Emaswidi laliphuti	=		–		=	
Emaswidi laphinki	=		–		=	



Khipha.

5 – 3 =	10 – 6 =	12 – 3 =
11 – 5 =	15 – 7 =	12 – 4 =
14 – 9 =	14 – 8 =	11 – 4 =
18 – 9 =	12 – 5 =	16 – 8 =
13 – 7 =	15 – 6 =	14 – 7 =





3 Cedzela.

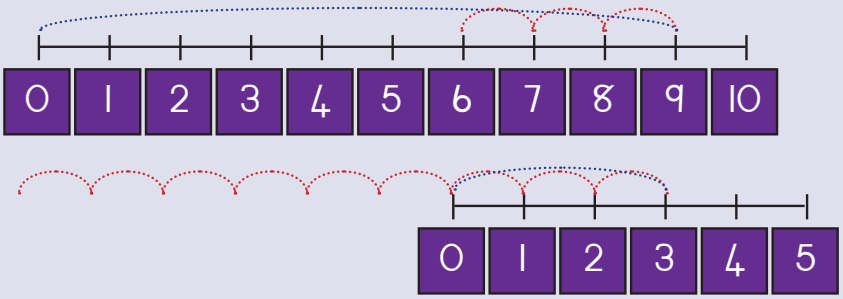

9 – 3

Akulingani na

3 – 9

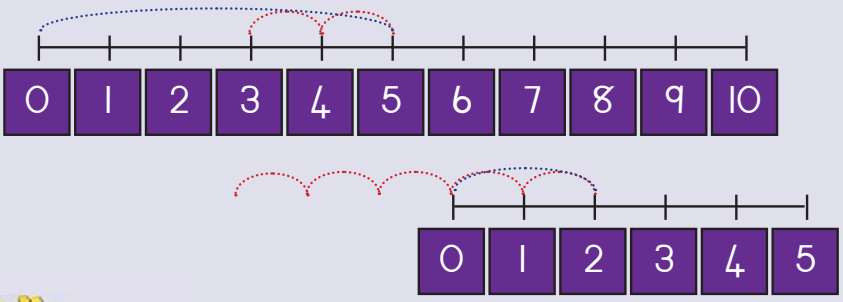

5 – 2

Akulingani na

2 – 5

4 Bhala sibalo sa.

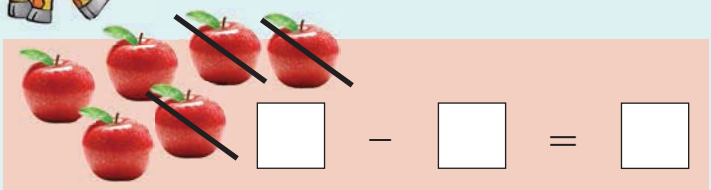

□ – □ = □





□ – □ = □

□ – □ = □





□ – □ = □

Teacher:

Sign:

Date:



11 12 13 14 15 16 17 18 19 20

Lusuku:

Kuhlanganisa (kuyachubeka)



Catsanisa lamakhadi.

2 10	8 10	7 10	5 10	3 10

7 + 10 = 17	10 + 2 = 12	10 + 5 = 15	3 + 10 = 13	10 + 8 = 18



Catsanisa lamakhadi. Kwekucala sesikwentele.

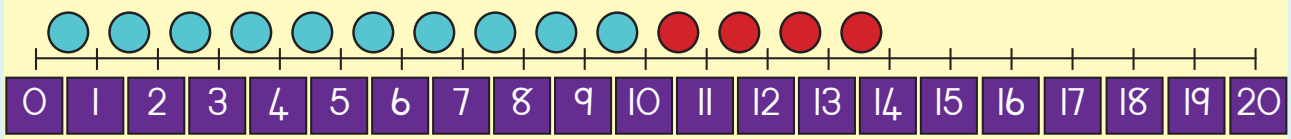

10 + 4 = 14

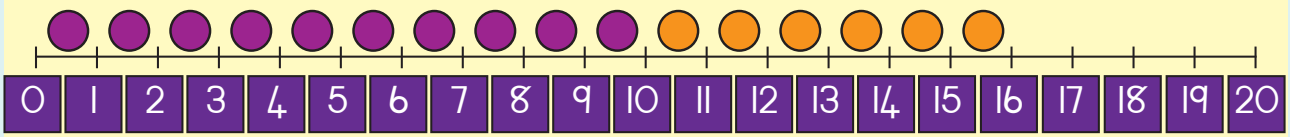

__ + __ = __

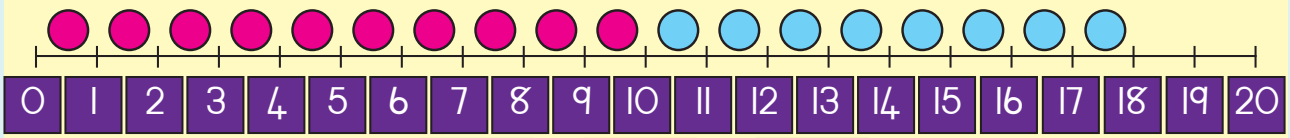

__ + __ = __

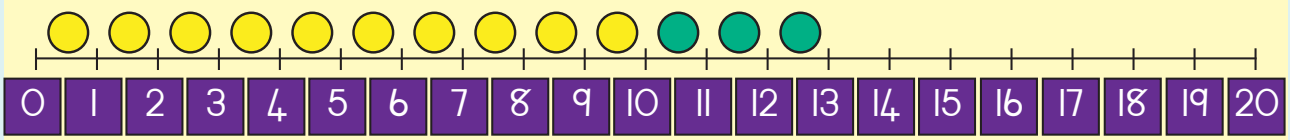

__ + __ = __







Hlanganisa.

10	+	3	=	13	10	+	2	=	
10	+	5	=		10	+	7	=	
10	+	1	=		10	+	6	=	
10	+	4	=		10	+	8	=	
10	+	9	=		10	+	3	=	



Hlanganisa.

16 + 13

10		10		20			
6	+	3	=	9			
16	+	13	=	29			

14 + 12

10		10					
4	+	2	=				
	+		=				

17 + 11

10		10					
7	+	1	=				
	+		=				

15 + 13

10		10					
5	+	3	=				
	+		=				

16 + 12

10		10					
6	+	2	=				
	+		=				

18 + 12

10		10					
8	+	2	=				
	+		=				



Lisa unetintfo tekubala letingu 9 kantsi Peter una 8.

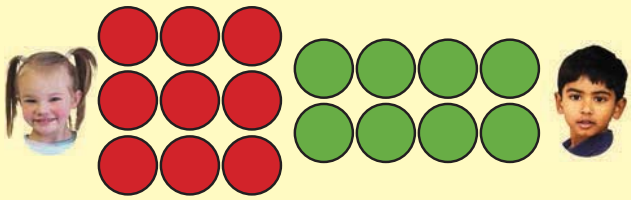

Itsini ithothali?

Teacher:

Sign:

Date:



11 12 13 14 15 16 17 18 19 20

Lusuku:

Imali

1 Liyini lidlela-ntfongeni lami?



2 Sika imali lebuhhehlu kuLokujutjiwe 3 bese unamatsisela emanani emali lafanele lapha.

50c	70c
90c	60c
40c	80c



Mangakhi emasenti?

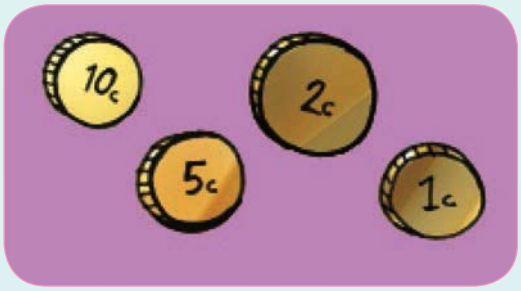

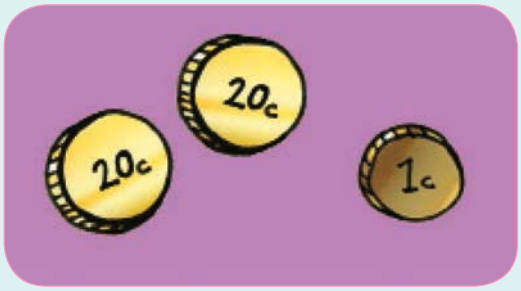





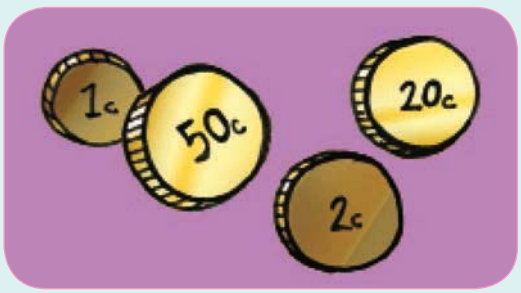

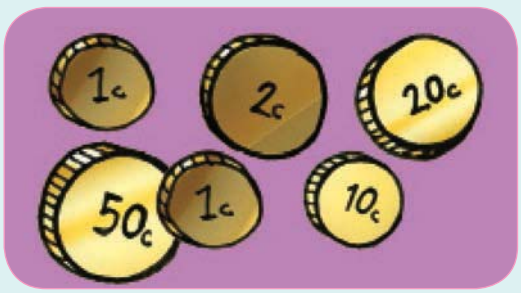



Tibalo-magama.

Suzy una 50c. Unina umnika 20c ngetulu. Sewunamalini nyalo Suzy?

_____

Ngina 90c. Ngitsenge liswidi la 30c. Senginamalini nyalo lesele?

_____

Teacher:

Sign:

Date:

11 12 13 14 15 16 17 18 19 20

Lusuku:

Imali yeliphepha

Inganani imali lesesipatjini sami?

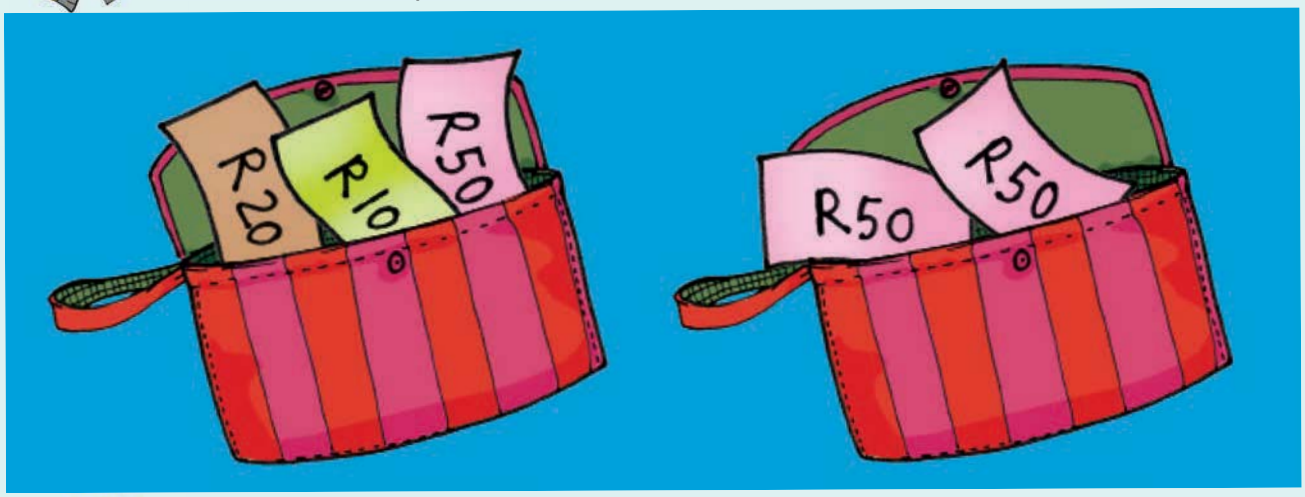

Sika emaphepha-mali kuLokujutjiwe 3 bese unamatsisela emanani lafanele lapha.

	
	
	





Mangakhi emaRandi?



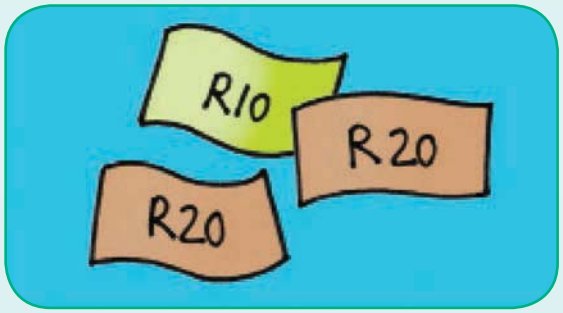

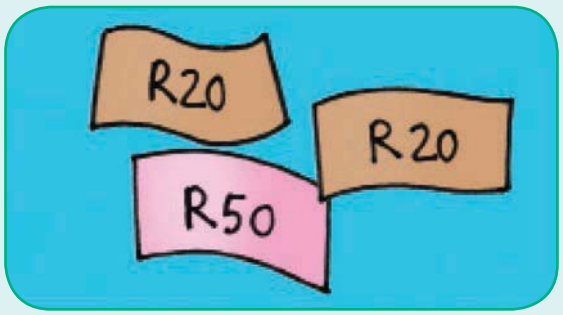

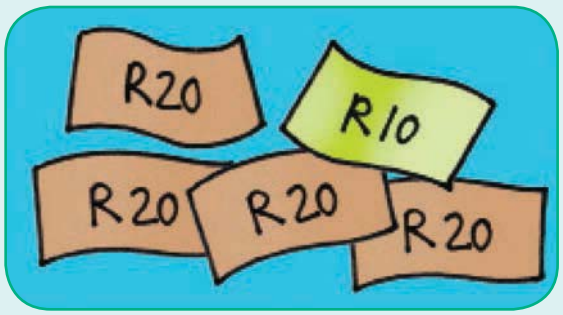







Tibalo-magama.

Ngonge R50. Ngatfola R20 welusuku lwami lwekutalwa. Senginamalini nyalo?

_____

Ngina R90. Ngitsenge incwadzi nga R30. Sengisele namalini?

_____

Teacher:

Sign:

Date:



Lusuku:

Emaphethini

1 Shaya tandla ulandzele lephethini.

shaya shaya shaya shaya shaya shaya shaya shaya shaya shaya shaya

shaya shaya

2 Kopa emaphethini. Sebentisa Lokujutjiwe 4.



3 Yenta sitfombe sakho ngebuhlalu lobusele. Sebentisa Lokujutjiwe 4.



Kopa lamaphethini lalandzelako.

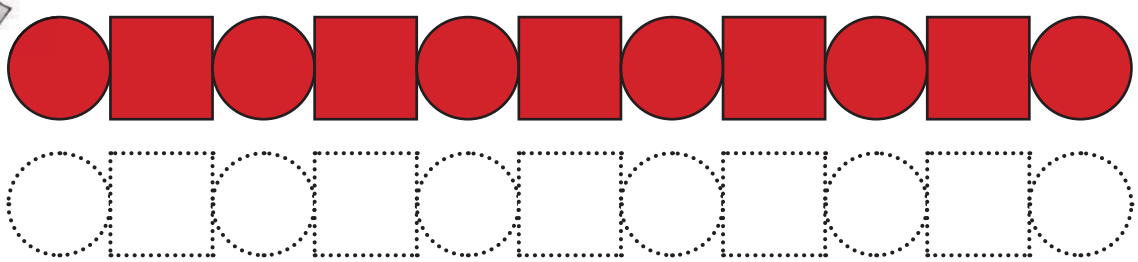



Kopa emaphethini.





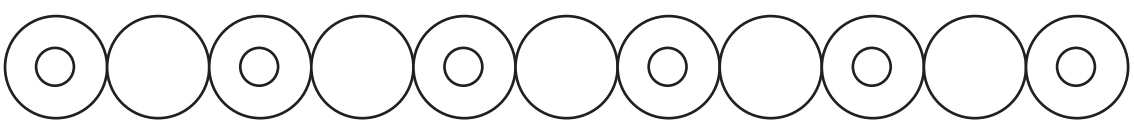

Teacher:

Sign:

Date:

Lusuku:

Emaphethini

1

Chaza iphethini ngayinye ngemagama. Lamagama langaphasi angakusita.



Calandze | Sikwele | Calantsatfu | Indingilizi | Imibala

2

Faka umbala kuphethini lelandzelako.



3

Dvweba iphethini lelandzelako.



4

Khulisa lephethini.

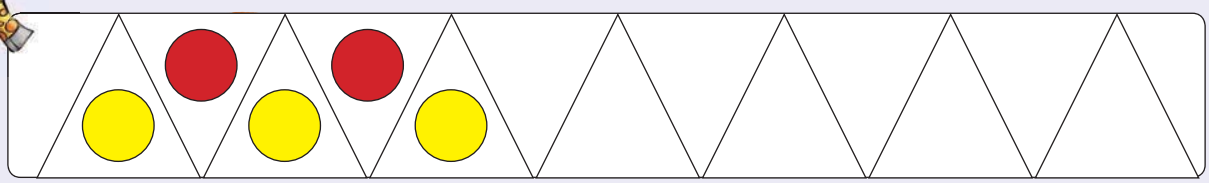





Dvweba emaphethini akho ngekusebentisa 



Dvweba iphethini lelandzelako.

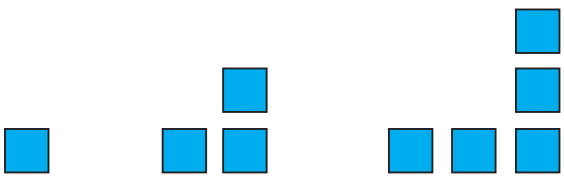





Cedzela loku lokulandzelako kute ube nendingilizi yinye etulu.

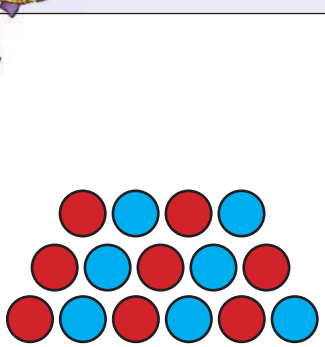

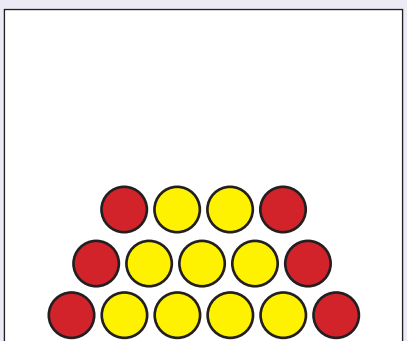

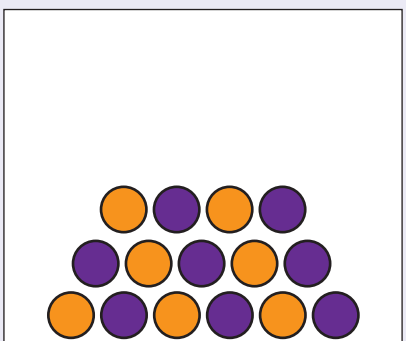



Sebentisa emaphethini emibala akho ngekusebentisa labobunjwa labangaphasi.

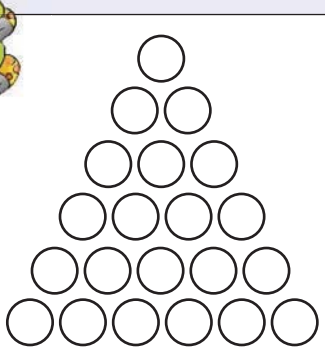

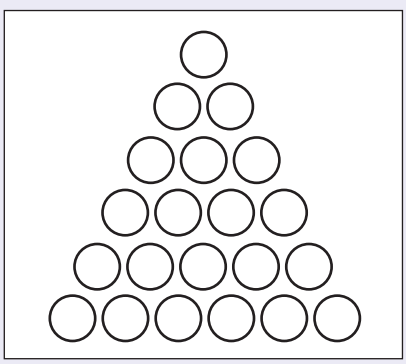

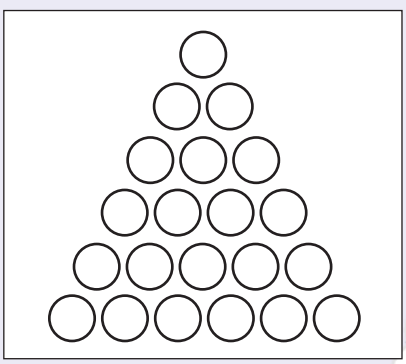



Teacher:

Sign:

Date:



11 12 13 14 15 16 17 18 19 20

Lusuku:

Kuphindzaphindza: x 2

Mangakhi emaswidi lakhona esibayeni ngasinye?



Uwabale kanjani lamaswidi? (labanye bantfwna bangatsi 1, 2, 3... labanye batsi 2, 4, 6 ...)

Cedzela loku lokulandzelako. Kwekucala sesikwentele.

4 emacembu a 2	2 + 2 + 2 + 2 = 8	4 × 2 = 8
5 emacembu a 2	2 + 2 + 2 + 2 + 2 =	5 × 2 =
6 emacembu a 2	2 + 2 + 2 + 2 + 2 + 2 =	6 × 2 =
7 emacembu a 2	2 + 2 + 2 + 2 + 2 + 2 + 2 =	7 × 2 =
8 emacembu a 2	2 + 2 + 2 + 2 + 2 + 2 + 2 + 2 =	8 × 2 =

Yenta umdvwebo waloku lokulandzelako.

3 emacembu a 2

4 emacembu a 2

9 emacembu a 2



Yenta umdvwebo waloku lokulandzelako.

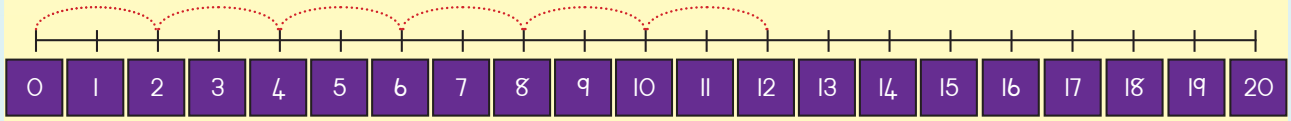

2, 4, 6, 8, ___ , ___

2 + 2 + 2 + 2 + 2 + 2 = ☐

6 × 2 = ☐

Umdvwebo



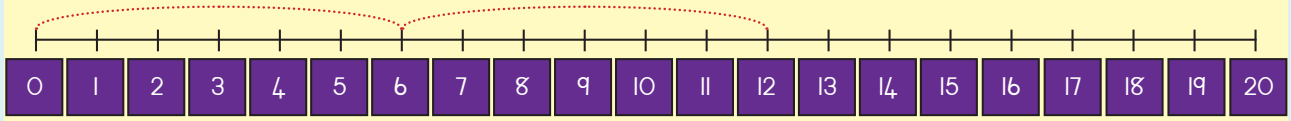

6, ___

6 + ☐ = ☐

2 × ☐ = ☐

Umdvwebo



Sayobi sinye sinemehlo langu 8. Ngabe tayobi letingu 7 tinamangakhi emehlo?

☐



2 4 6 8 10 12 14

16 18 20 22 24 26

Teacher:

Sign:

Date:



11 12 13 14 15 16 17 18 19 20

Lusuku:

Kuphindzaphindza: x 5

1 Mangakhi emaswidi lakhona esibayeni ngasinye?



2 Cedzela loku lokulandzelako. Kwekucala sesikwentele.

3 emacembu a 5	5 + 5 + 5 = 15	3 × 5 = 15
2 emacembu a 5	5 + 5 =	2 × 5 =
4 emacembu a 5	5 + 5 + 5 + 5 =	4 × 5 =
6 emacembu a 5	5 + 5 + 5 + 5 + 5 + 5 =	6 × 5 =
7 emacembu a 5	5 + 5 + 5 + 5 + 5 + 5 + 5 =	7 × 5 =

3 Yenta umdvwebo waloku lokulandzelako.

3 emacembu a 5	4 emacembu a 5	5 emacembu a 5





Yenta umdvwebo waloku lokulandzelako.

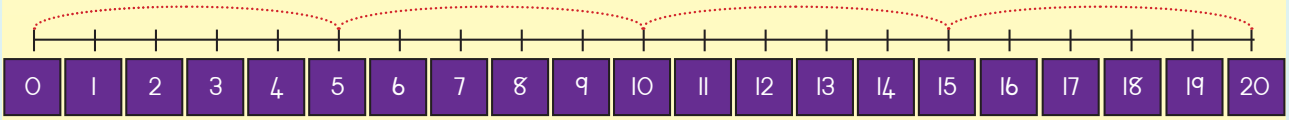

5, 10, 15, ___

5 + 5 + 5 + 5 = ☐

4 × 5 = ☐

Umdvwebo

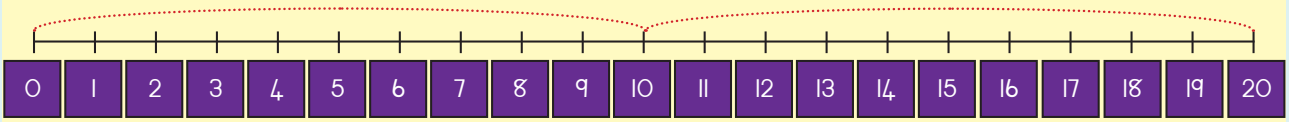

10, ___

10 + ☐ = ☐

10 × ☐ = ☐

Umdvwebo



5 10 15 20 25 30

35 40 45 50

Teacher:

Sign:

Date:

Lusuku:

Tindzaba tekuphindzaphindza letengetiwe

Yenta indzaba yakho ngekusebentisa sibalo lesiphelele setindlebe, tandla kanye netinyawo.



Sibangani labangu 10. Sineminwe lemingakhi?

Yenta umdvwebo.

Wukhombise ngetintfo tekubala.

Wukhombise kumugcanombolo.

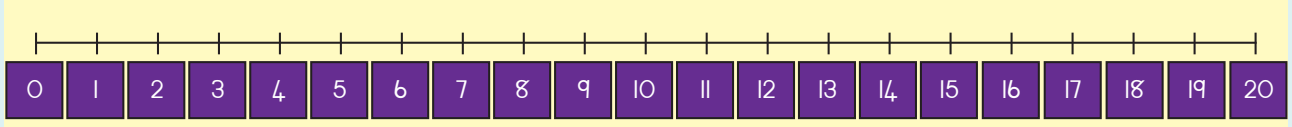

____ + ____ = ____ ____ × ____ = ____





Umndeni waSusan unemapheya langu 10 eticatfulo. Baneticatfulo letingakhi?

Yenta umdvwebo.

Wukhombise ngetintfo tekubala.

Wukhombise kumugcanombolo.

0	1	2	3	4	5	6	7	8	9	10	11	12	13	14	15	16	17	18	19	20



+ = ☐ ☐ × ☐ = ☐

Bhala yakho indzaba usebentise bantfwana labangu 6 netandla tabo.



5 10 15 20 25 30 35

Teacher:
Sign:
Date:



Lusuku:

Tikwele, bocalandze, bocalantsatfu netindilinga (kuyachubeka)





Faka umbala lobovu kuwo onkhe lamabhola, lolingangane kulamabhokisi kanye naloluhlata kulemibhoshongo.

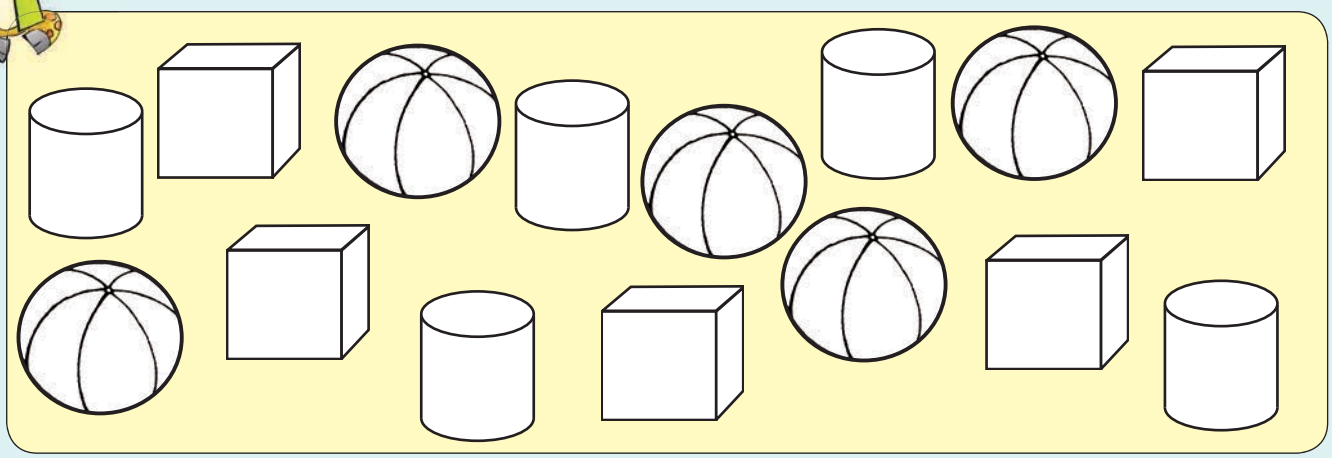



Khetsa ligama lelifanele.



imiphetfo lecondzile

imiphetfo legwenjile

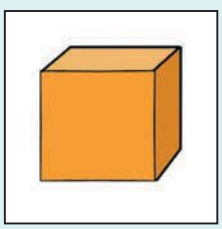

imiphetfo lecondzile

imiphetfo legwenjile



imiphetfo lecondzile

imiphetfo legwenjile



3

Shano kutsi lentfo itawugicika nobe itawushelela.



itawugicika

itawushelela

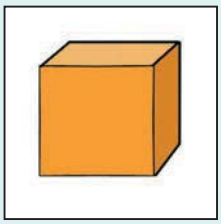

itawugicika

itawushelela



itawugicika

itawushelela

4

Kungakhi kwaletintfo lokubonako kulesitfombe: imibhoshongo, emabhokisi nemabhola?

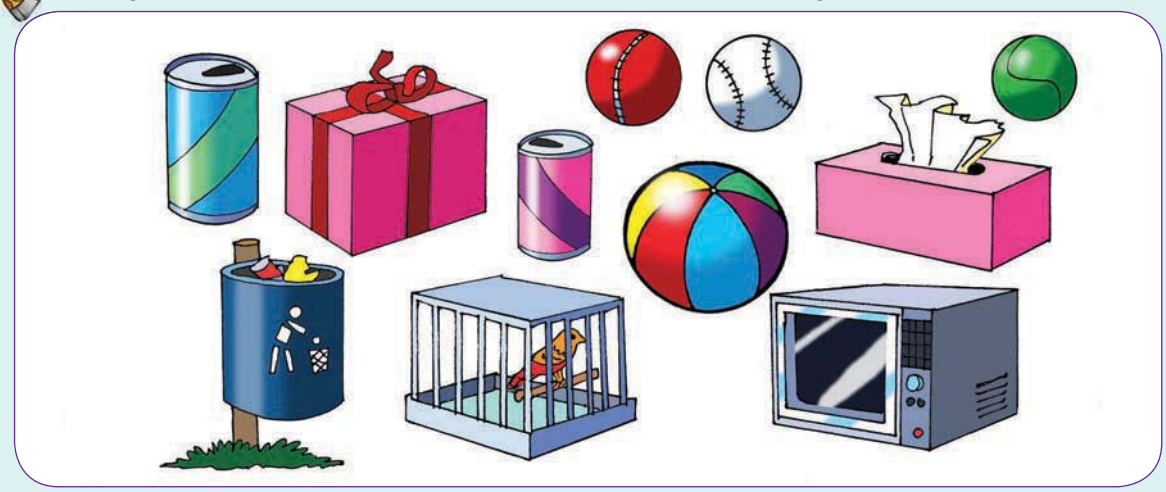

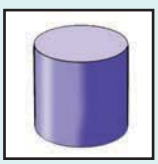

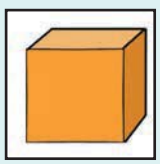



5

Dvweba sitfombe sakho usebentise emabhola, emabhokisi nemibhoshongo.

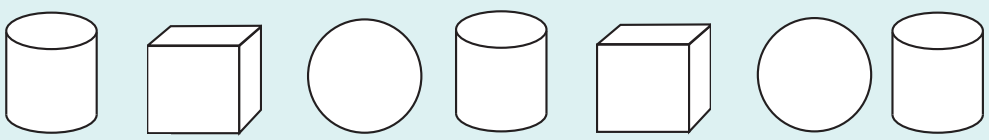



11 12 13 14 15 16 17 18 19 20

Teacher:

Sign:

Date:

Lusuku:

Catsanisa bese uhlela tinombolo: 1–40

Ngubani lonemawolintji lamanyenti?





Ngubani lonemahhabhula lamanyenti?





Bala buhlalu bese ugcwalisa emabhokisi langenalutfo.

1	2	3	4	5		7			10
	12				16		18		
21				25	26				30
31					36				40

Buka kulobuhlalu bese uphendvula lemibuto.

Nguyiphi inombolo lencane kuna 8? ☐

Nguyiphi inombolo lenkhulu kuna 13? ☐

Nguyiphi inombolo lencane kuna 20? ☐

Nguyiphi inombolo lencane kuna 24? ☐



Faka imibala lebovu etinombolweni letincane kuna 20 kantsi tingetulu kwa 10.

1	2	3	4	5	6	7	8	9	10
11	12	13	14	15	16	17	18	19	20

Faka umbala lolingangane etinombolweni letincane kuna 30 kantsi tingetulu kwa 24.

20	21	22	23	24	25	26	27	28	29	30

Faka umbala loluhlata etinombolweni letincane kuna 40 kantsi tingetulu kwa 36.

30	31	32	33	34	35	36	37	38	39	40

Faka umbala lomtfubi kutinombolo leticondzile bese ufaka loluhlata kutinombolo lugweje.

1	2	3	4	5	6	7	8	9	10
11	12	13	14	15	16	17	18	19	20
21	22	23	24	25	26	27	28	29	30
31	32	33	34	35	36	37	38	39	40
41	42	43	44	45	46	47	48	49	50

Nguyiphi inombolo lugweje leta ngemuva kwa 10?

Nguyiphi inombolo lecondzile leta ngaphambi kwa 10?

Bhala phasi tinombolo leticondzile emkhatsini wa 14 na 28?

Bhala phasi tinombolo lugweje emkhatsini wa 5 na 15?

Nguyiphi inombolo lecondzile leta nje ngemuva kwa 21?

Nguyiphi inombolo lecondzile leta nje ngaphambi kwa 24?

Bhala phasi tinombolo leticondzile emkhatsini wa 20 na 30?

Bhala phasi tinombolo lugweje emkhatsini wa 20 na 30?

Teacher:
Sign:
Date:

11 12 13 14 15 16 17 18 19 20

Lusuku:

Hlela uphindze ucatsanise: 40–50

1 Ngubani lonabophayinaphu labanyenti?









2 Bala buhlalu bese ugcwalisa emabhokisi langenalutfo.

1	2	3	4	5					
								19	
							28		

	32								
									30
51	52	53	54	55	56	57	58	59	60

3 Buka kulobuhlalu bese uphendvula lemibuto.

Nguyiphi inombolo lencane kuna 3? ____

Nguyiphi inombolo lenkhulu kuna 31? ____

Nguyiphi inombolo lencane kuna 38? ____

Nguyiphi inombolo lencane kuna 47? ____





Faka umbala loluhlata kuletinombolo letincane kuna 40 nakuleti letinkhulu kuna 36.

30	31	32	33	34	35	36	37	38	39	40

Tinombolo letincane kuna 40.

Tinombolo letinkhulu kuna 36.



Faka umbala lomtfubi kutinombolo leticondzile bese ufaka loluhlata kutinombolo lugweje.

40	41	42	43	44	45	46	47	48	49	50

Ngumuphi nombolo lugweje lota ngemuva kwa 40?

Nguyiphi inombolo lecondzile leta ngaphambi kwa 43?

Bhala phasi tinombolo leticondzile emkhatsini wa 40 na 50?

Bhala phasi tinombolo lugweje emkhatsini wa 40 na 50?

Tinombolo letimbili letincane kuna 40?

Tinombolo letimbili letinkhulu kuna 41?



Teacher:

Sign:

Date:



Lusuku:

Tinombolo 40–50

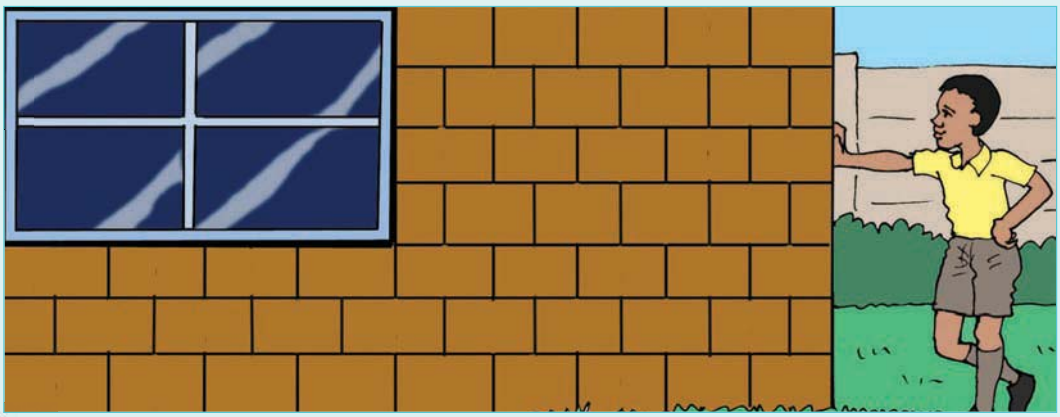

Bungakhi buhlalu lobubalako?

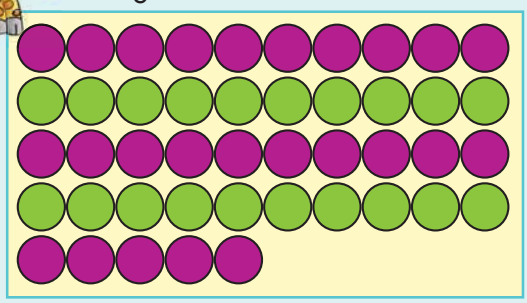

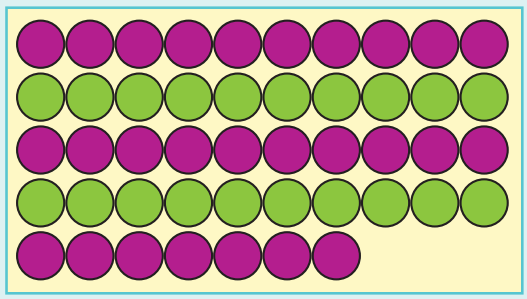

Inombolo	singayibhala njenga:	Inombolo	singayibhala njenga:
45	40 + 5 = 45		+ =

Cedzela loku lokulandzelako.

20	21	22							
30				34					
		42							

Cedzela loku lokulandzelako.



20 +  4 = 24



+  =





Bhala emagama aloku.

41	_____	42	_____
43	_____	44	_____
45	_____	46	_____
47	_____	48	_____
49	_____	50	_____



Buka sibonelo sekucala bese ucedzela konkhe lokulandzelako.

45	=	4	lishumi	+	5	emayunithi		
43	=		lishumi	+		emayunithi		
42	=		lishumi	+		emayunithi		

44	=		lishumi	+		emayunithi		
41	=		lishumi	+		emayunithi		
48	=		lishumi	+		emayunithi		



Bhala inombolo kukholomu lefanele.

	Emayunithi	Emashumi
27		
34		
46		
41		
39		



Teacher:
Sign:
Date:





Lusuku:

Tikwele, bocalandze, bocalantsatfu netindilinga

1 Gogo wente lomtfungo lomuhle. Khombisa bonkhe bobunjwa.

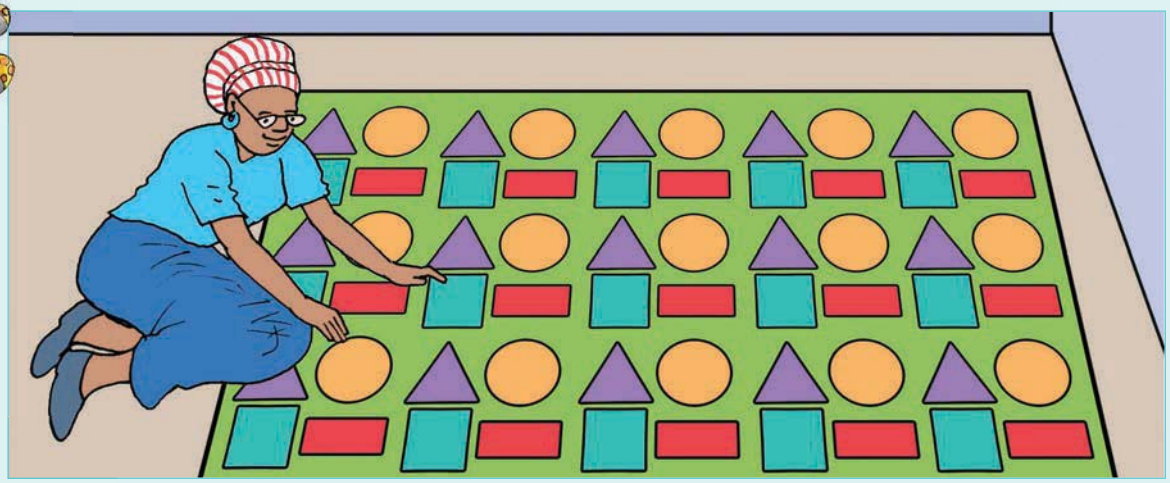

2 Faka umbala lolingangane kuletikwele, lomtfubi kulabocalandze, loluhlata kulabocalantsatfu kantsi lobovu kuletindilinga.

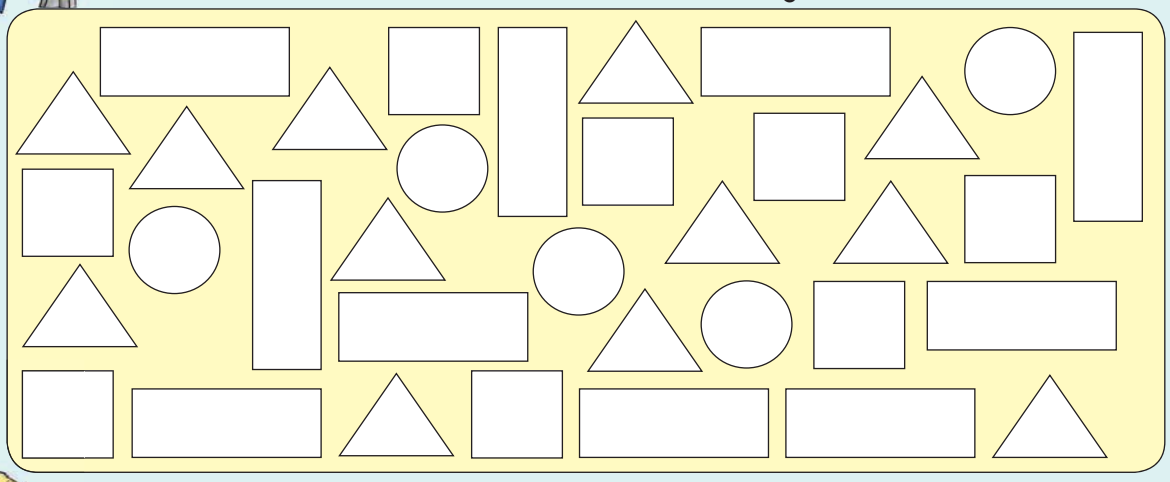

3 Khetsa imphendvulo leliciniso.



imiphetfo lecondzile
imiphetfo leyindilinga



imiphetfo lecondzile
imiphetfo leyindilinga



imiphetfo lecondzile
imiphetfo leyindilinga



imiphetfo lecondzile
imiphetfo leyindilinga



Bangakhi labobunjwa lobatfolile?



Dvweba sitfombe sakho usebentise tindingilizi, tikwele, bocalantsatfu nabocalandze.

Teacher:
Sign:
Date:

11 12 13 14 15 16 17 18 19 20

Lusuku:

Imisebenti leminyenti 1–20

1 Kukhumbula masinyane.

4 + 5 − 1 =	13 − 9 + 2 =	20 − 7 + 1 =	10 + 5 − 4 =
10 + 3 + 2 =	9 + 3 − 2 =	8 − 2 − 1 =	13 − 8 + 1 =
9 − 4 − 3 =	18 − 9 − 4 =	7 + 8 + 1 =	16 − 7 + 3 =
14 − 6 + 4 =	12 − 5 − 2 =	19 − 10 + 5 =	6 + 5 − 3 =

2 Hlanganisa loku lokulandzelako.

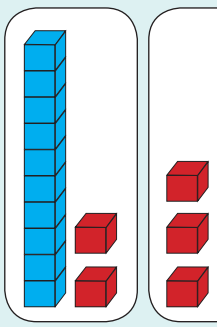

= 10 2 + 6

= 10 + 8

= 18

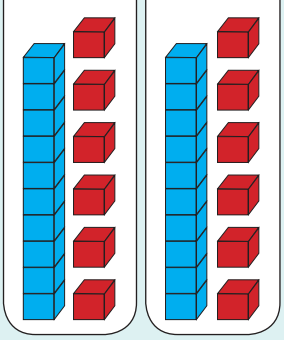

= + + +

= + +

= +

=

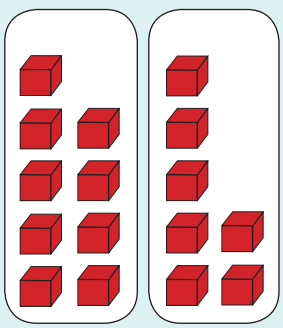

= +

= +

=



Susa loku lokulandzelako.

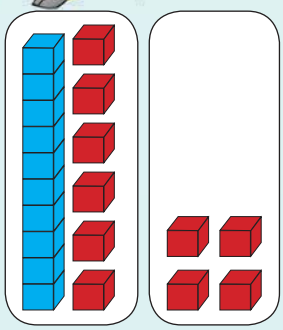

= 10 6 − 4

= 10 − 2

= 8

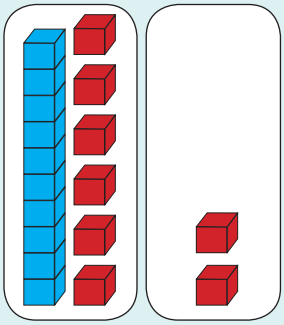

= ☐ ☐ + ☐ ☐

= ☐ − ☐

= ☐

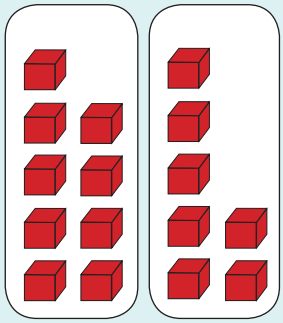

= ☐ − ☐

= ☐

Ngitsenge emaswidi langu 15. Ngidle 2.
Nginikete umngani wami 4. Nginemaswidi lamangakhi?



Teacher:
Sign:
Date:

11 12 13 14 15 16 17 18 19 20

Lusuku:

Imisebenti leminyenti 20–50

1 Kukhumbula masinyane.

20 + 2 – 1 =	36 – 6 + 2 =	42 – 2 + 4 =	47 + 4 – 1 =
30 + 3 + 6 =	42 + 9 – 1 =	33 – 2 – 1 =	49 – 1 + 2 =
55 – 5 – 0 =	38 – 7 – 1 =	45 + 1 + 2 =	50 – 5 + 3 =
24 – 3 + 2 =	32 – 5 – 2 =	49 – 10 + 1 =	29 + 5 – 4 =

2 Hlanganisa loku lokulandzelako.

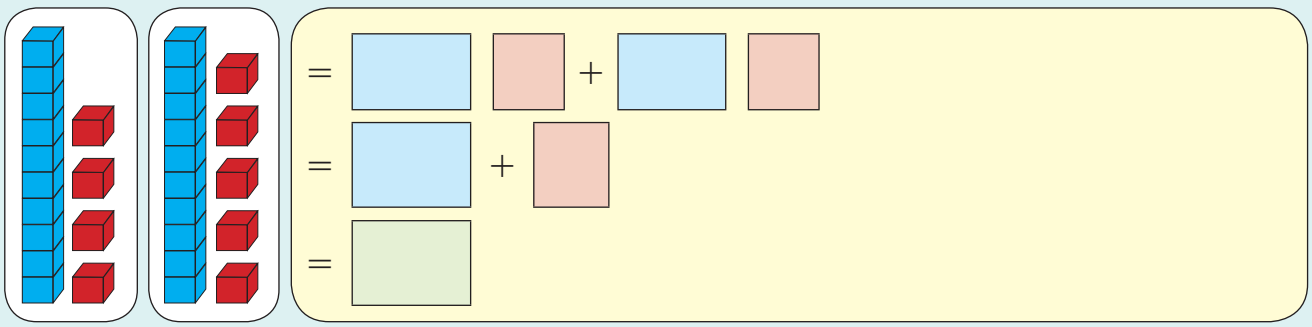

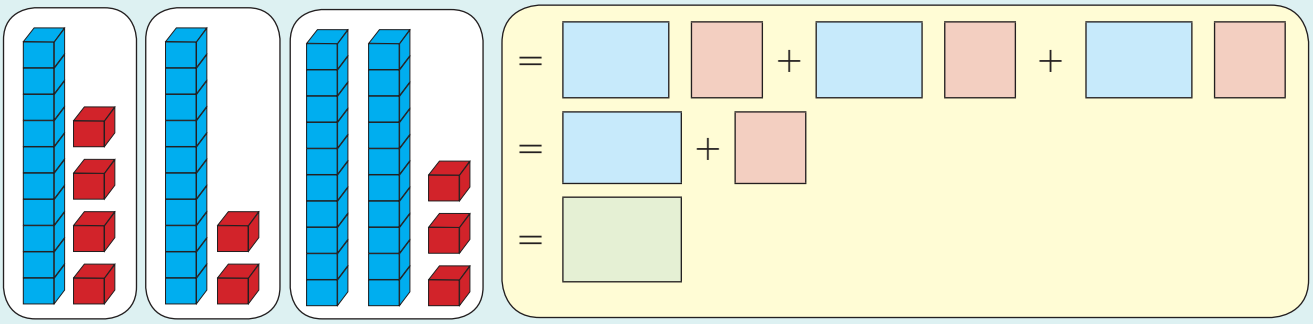

Sale usebentisa indlela yakho.

Susa loku lokulandzelako.

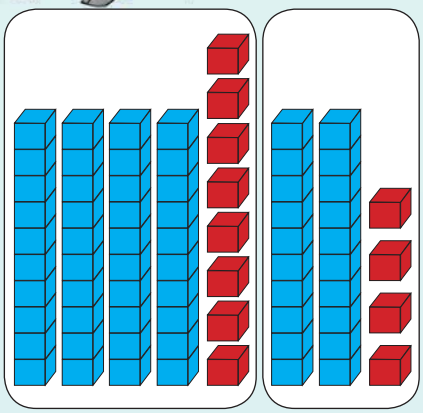

= 40 8 − 20 4

= 40 − 20 + 8 − 4

= ☐ − ☐

= ☐

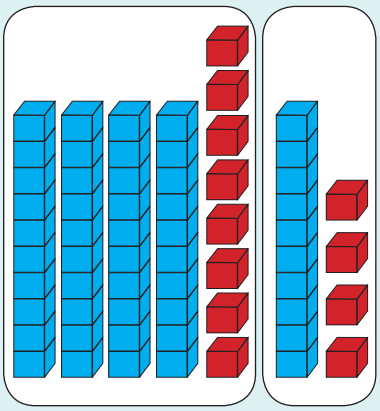

= ☐ ☐ − ☐ ☐

= ☐ − ☐ + ☐ − ☐

= ☐ − ☐

= ☐

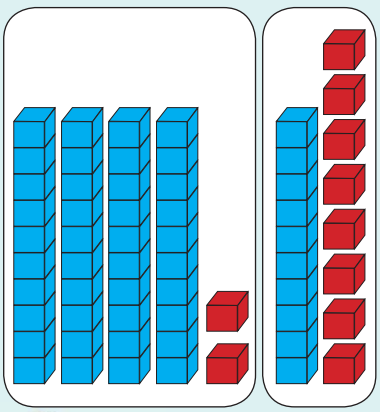

= ☐ ☐ − ☐ ☐

= ☐ − ☐ + ☐ − ☐

= ☐ − ☐

= ☐

Ngina R10, R5, R20 na R2 kulidlelantfongeni lami. Ngonge malini?

R20 R5 R2 R10

Lusuku:

Kuhlanganisa lokwengetiwe



Catsanisa lamakhadi.

1 10 5 10	2 10 6 20	3 20 5 20	4 20 4 10



Hlanganisa:

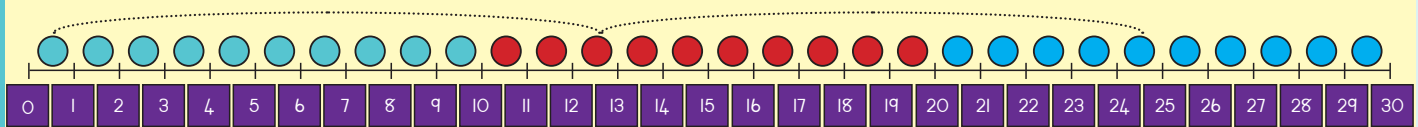

13 + 12 = ☐

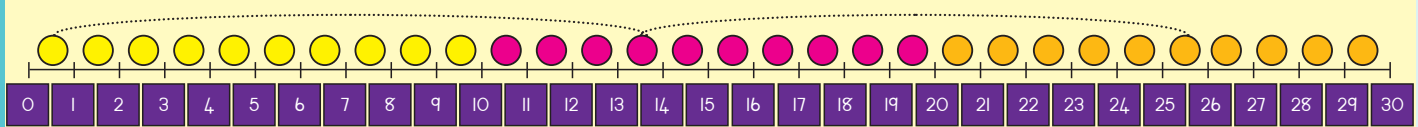

14 + 12 = ☐

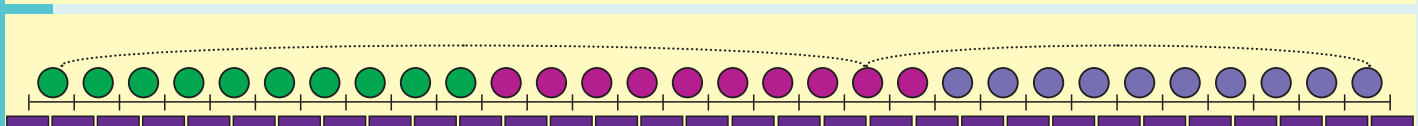

19 + 11 = ☐

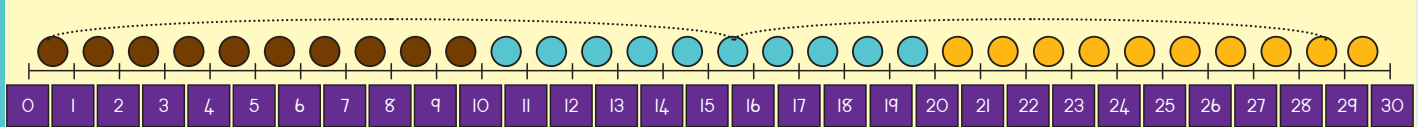

16 + 13 = ☐

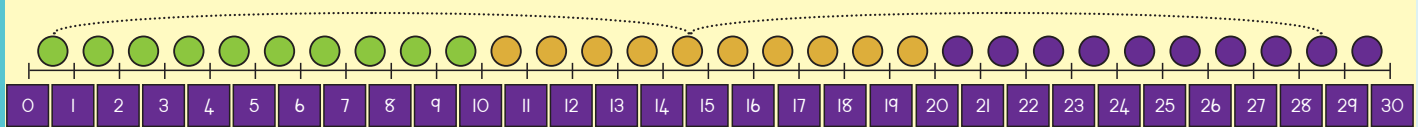

15 + 14 = ☐





Hlanganisa:

12 + 11

= 10 2 + 10 1

= 10 + 10 + 2 + 1

= 20 + 3

= 23

13 + 15

= ☐ ☐ + ☐ ☐

= ☐ + ☐ + ☐ + ☐

= ☐ + ☐

= ☐

26 + 12

= ☐ ☐ + ☐ ☐

= ☐ + ☐ + ☐ + ☐

= ☐ + ☐

= ☐

23 + 22

= ☐ ☐ + ☐ ☐

= ☐ + ☐ + ☐ + ☐

= ☐ + ☐

= ☐

24 + 13

= ☐ ☐ + ☐ ☐

= ☐ + ☐

= ☐

35 + 12

= ☐ ☐ + ☐ ☐

= ☐ + ☐

= ☐

Betty utsenge emaswidi aR36, Sipho watsenga aR13. Batsenge ngamalini seyiyonkhe?

Teacher:

Sign:

Date:

11 12 13 14 15 16 17 18 19 20



Lusuku:

Kuhlanganisa lokwengetiwe (kuyachutjekiswa)



Itsini ithothali yemugca ngamunye?

12 + 10 = ☐

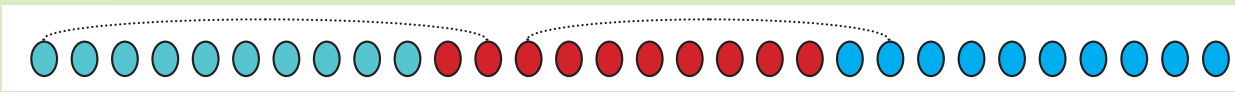

15 + 10 = ☐

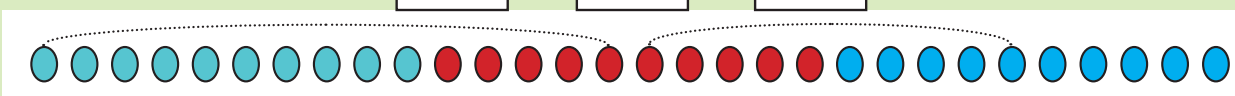

19 + 10 = ☐

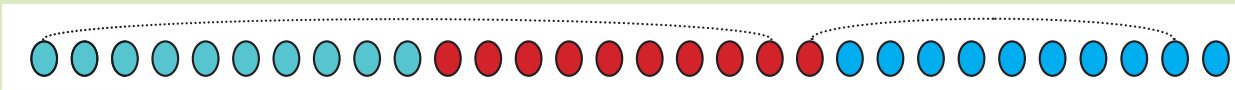



Dvweba bonkhe lobuhlalu bese ucedzela letibalo.

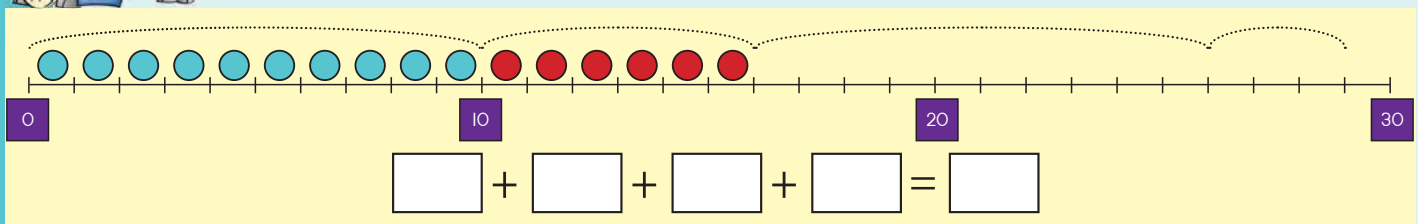

☐ + ☐ + ☐ + ☐ = ☐

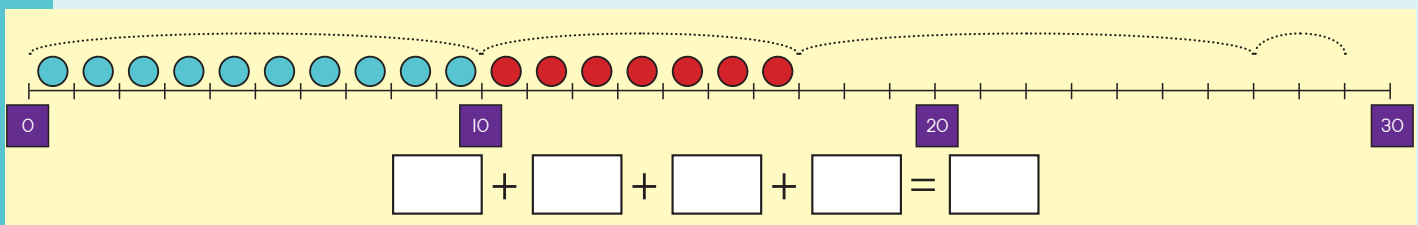

☐ + ☐ + ☐ + ☐ = ☐

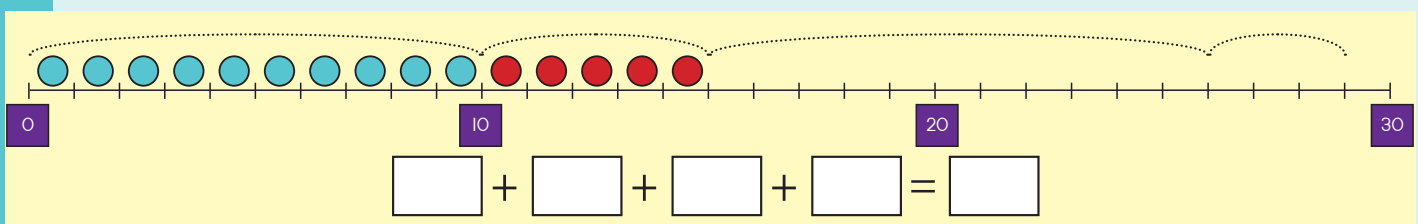

☐ + ☐ + ☐ + ☐ = ☐

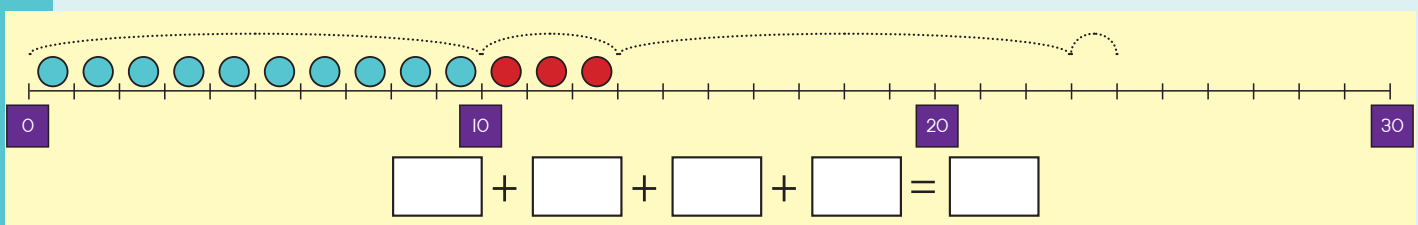

☐ + ☐ + ☐ + ☐ = ☐



1 2 3 4 5 6 7 8 9 10



3 Cedzela.

28	+	11	=	2	8	+	10	+	1	=	38	+	1	=	39
34	+	12	=	3	4	+	10	+	2	=		+		=	
23	+	13	=	2	3	+	10	+	3	=		+		=	
35	+	12	=	3	5	+	10	+	2	=		+		=	
26	+	11	=	2	6	+	10	+	1	=		+		=	

4 Hlanganisa

11 + 10 =	23 + 10 =	36 + 10 =
28 + 10 =	37 + 10 =	12 + 10 =
34 + 10 =	29 + 10 =	15 + 10 =

5 Sibalo sa 7 na 6 ngu? ☐
Dvweba sitfombe kukhombisa imphendvulo yakho.

6 Yenta sibalo sakho semagama ngekusebentisa titfombe.



Teacher:
Sign:
Date:



Lusuku:

Budze



Khombisa kutsi nguyiphi ibhuloki lendze noma lemfisha ngekufaka umbala kumphendvulo, umbala lofana nemabhuloki.

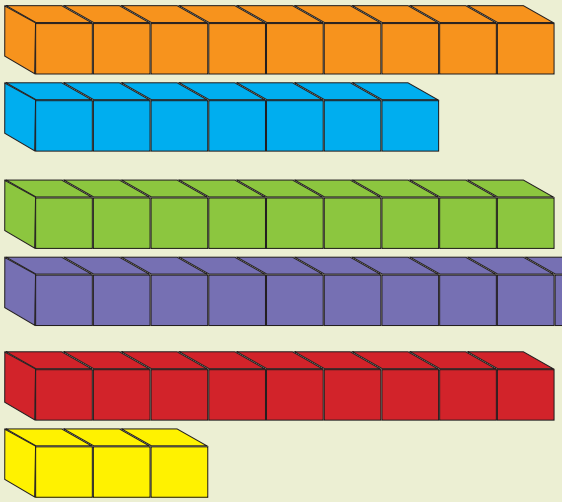

kufisha | kujana

kufisha | kujana

kufisha | kujana

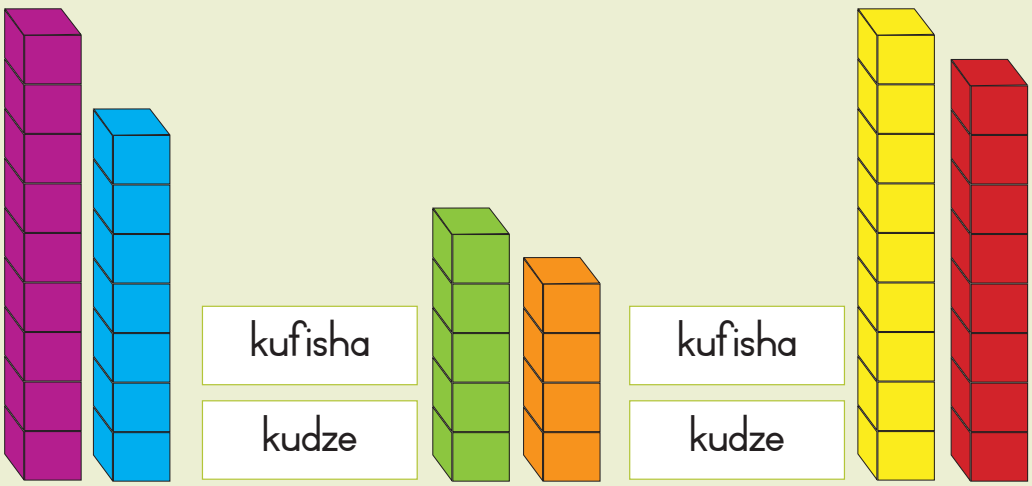

kufisha | kudze

kufisha | kudze

kufisha | kudze

1 2 3 4 5 6 7 8 9 10



2 Faka umbala lofana nemabhulukwe emfana.



mfisha | mudze



mudze | mfisha



mfisha | mudze



Linganisa emacala elibala lekudlala ngesandla nangelunyawo kuLokujutjiwe I

Ngabe libala lekudlala lidze ngetandla letingakhi?

Ngabe libala lekudlala lidze ngetinyawo letingakhi?

budze



Lusuku:

Kususa (kuyachutjekiswa)



Catsanisa lamakhadi.

10	10	10	10	10
2 2	8 8	7 7	5 5	3 3
17 – 7 = 10	12 – 2 = 10	15 – 5 = 10	13 – 3 = 10	18 – 8 = 10



Sebentisa lomugcanombolo. Bhala sibalo sekususa.

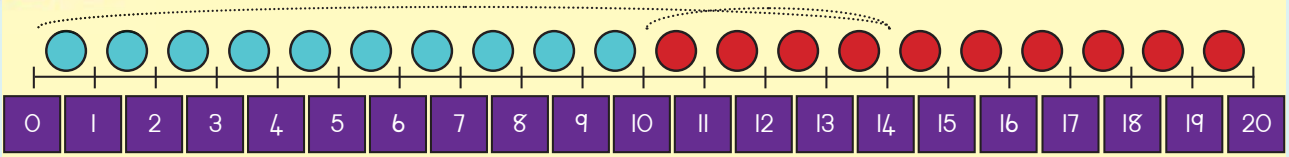

14 – 4 = 10

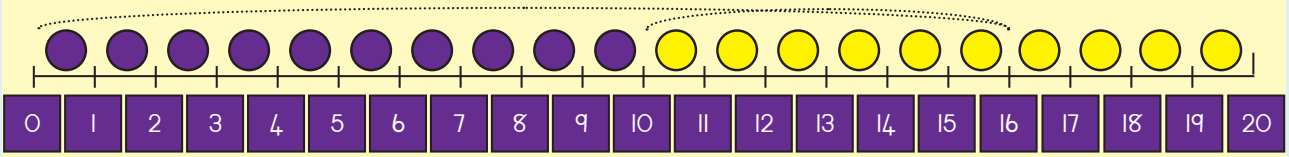

__ – __ = __

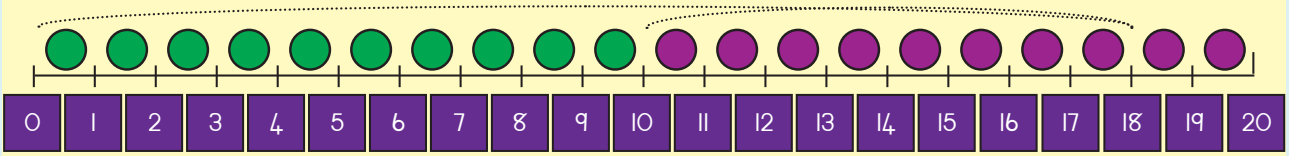

__ – __ = __

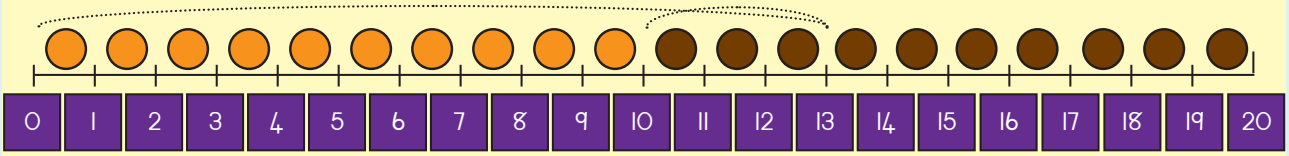

__ – __ = __





Kususa.

10	3	−	3	=		10	2	−	2	=	
10	5	−	5	=		10	7	−	7	=	
10	1	−	1	=		10	6	−	6	=	
10	4	−	4	=		10	8	−	8	=	
10	9	−	9	=		10	9	−	5	=	



Kususa.

16 – 13

10	10		20	
6		3	=	3

16 – 13 = 3

14 – 12

10	10			
4		2	=	

14 – 12 = ☐

27 – 11

20	10			
7		1	=	

☐ – ☐ = ☐

35 – 13

30	10			
5		3	=	

☐ – ☐ = ☐

26 – 12

20	10			
6		2	=	

☐ – ☐ = ☐

48 – 11

40	10			
8		1	=	

☐ – ☐ = ☐



Lisa unetintfo tekubala letingu 17. Ulahlekelwe tintfo tekubala letingu 8.





Usele netintfo tekubala letingakhi? ☐

Teacher:
Sign:
Date:



11 12 13 14 15 16 17 18 19 20

Lusuku:

Lokunye ngekususa

Khipha tinombolo letingaphasi kuleti letingetulu.

10 − 7 = 17	20 − 2 =	30 − 8 =	40 − 9 =
10 − 5 = 15	10 − 1 =	10 − 5 =	10 − 4 =
2			

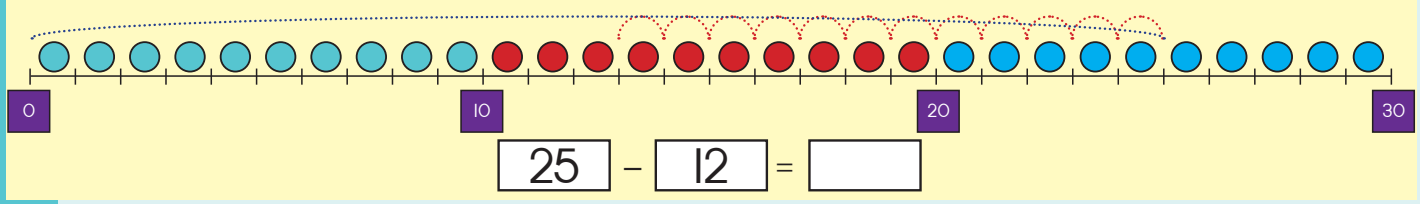

25 − 12 =

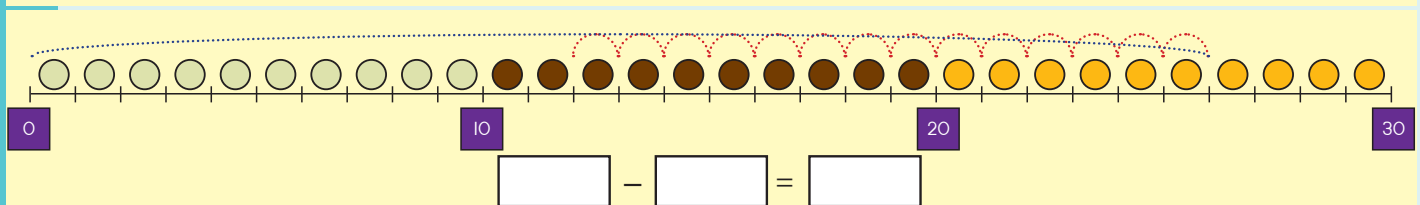

− =

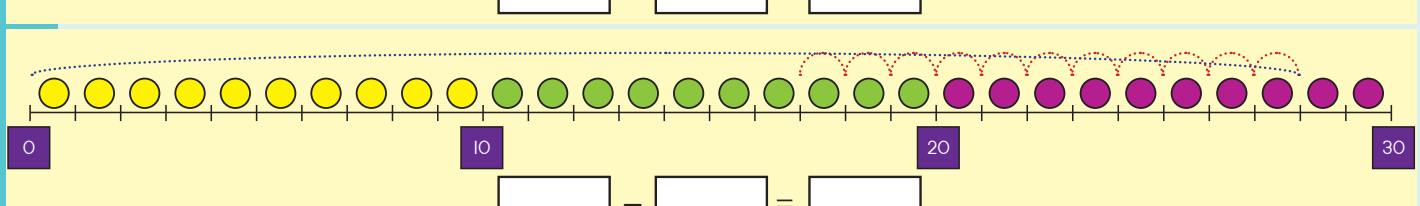

− =

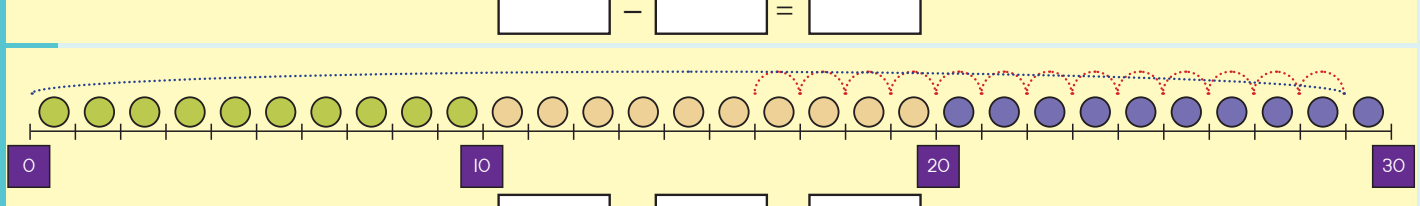

− =

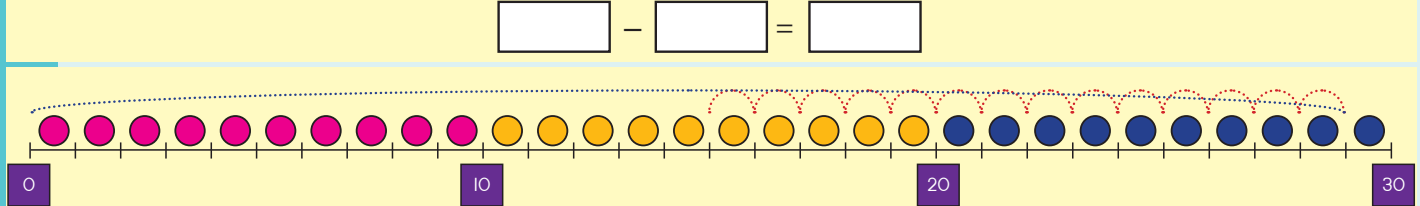

− =





Kususa.

45 – 23

= 40 [ ] – 20 3

= 40 – 20 + 5 – 3

= 20 + 2

= 22

38 – 16

= [ ] [ ] – [ ] [ ]

= [ ] – [ ] + [ ] – [ ]

= [ ] + [ ]

= [ ]

29 – 14

= [ ] [ ] – [ ] [ ]

= [ ] – [ ] + [ ] – [ ]

= [ ] + [ ]

= [ ]

48 – 11

= [ ] [ ] – [ ] [ ]

= [ ] – [ ] + [ ] – [ ]

= [ ] + [ ]

= [ ]

35 – 23

= [ ] [ ] – [ ] [ ]

= [ ] – [ ] + [ ] – [ ]

= [ ] + [ ]

= [ ]

38 – 15

= [ ] [ ] – [ ] [ ]

= [ ] – [ ] + [ ] – [ ]

= [ ] + [ ]

= [ ]



Teacher:

Sign:

Date:



11 12 13 14 15 16 17 18 19 20

42b

Lusuku:

Kususa lokwengetiwe (kuyachutjekiswa)

1 Itsini ithothali yemugca ngamunye?

22 – 10 = ☐



25 – 10 = ☐

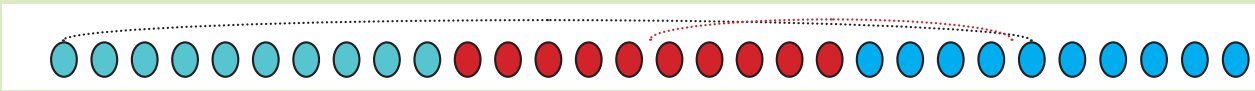

29 – 10 = ☐



2 Dvweba bonkhe lobuhlalu bese ucedzela letibalo.

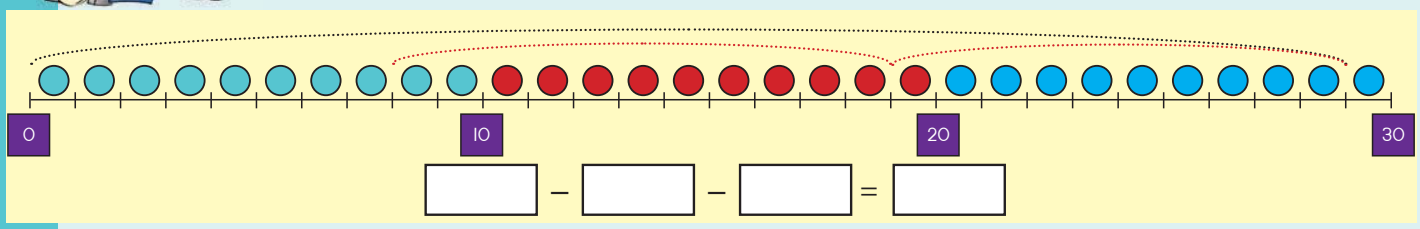

☐ – ☐ – ☐ = ☐

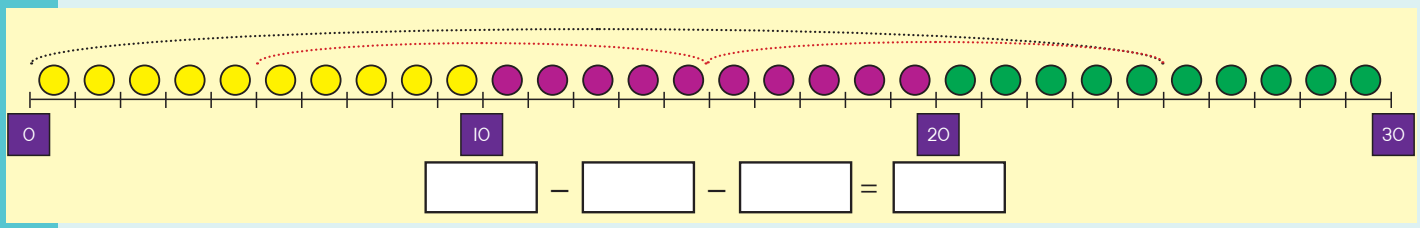

☐ – ☐ – ☐ = ☐

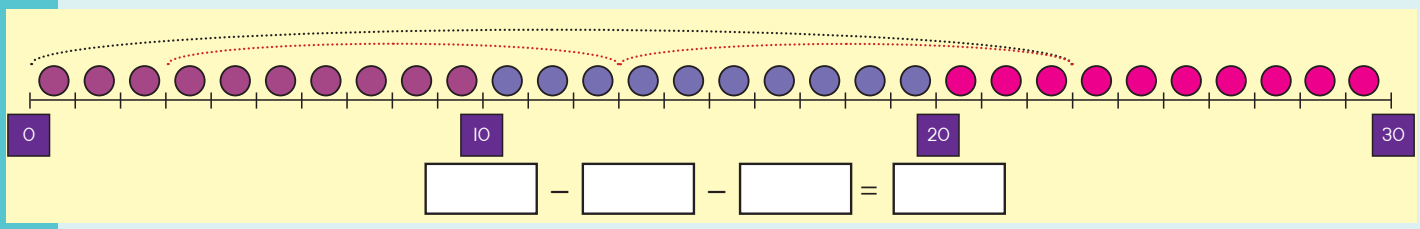

☐ – ☐ – ☐ = ☐

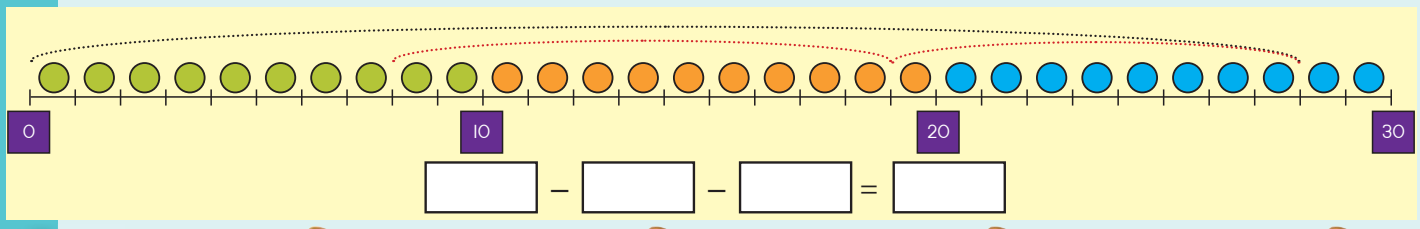

☐ – ☐ – ☐ = ☐

1 2 3 4 5 6 7 8 9 10





Cedzela.

46 − 13 =	38 − 14 =	25 − 11 =
49 − 23 =	27 − 16 =	46 − 32 =



Susa.

21 − 10 =	43 − 10 =	16 − 10 =
28 − 10 =	27 − 10 =	22 − 10 =
34 − 10 =	37 − 10 =	45 − 10 =



Umehluko emkhatsini wa 35 na 20 ngu? Dvweba sitfombe kukhombisa imphendvulo yakho.

35 − 20 = _____



Yenta sibalo semagama sakho ngekusebentisa titfombe.

_____ − _____ = _____



Teacher:

Sign:

Date:





Lusuku:

Kwesindza nebumalula

1 Buka letitfombe bese uphendvula lemibuto.

Ngukuphi lokumalula kakhulu? Ngukuphi lokwesindza kakhulu?



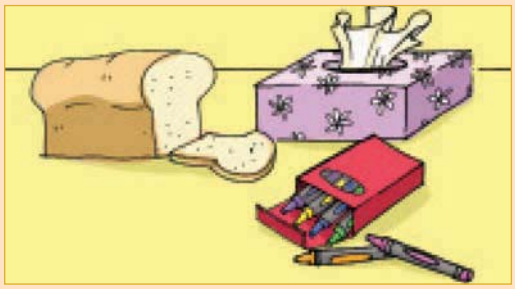

2 Namatsisela noma udvwebe titfombe taloku.

Tintfo letesindzako	Tintfo letimalula



Bumtfubi bukhombisa intfo lemalula bese lingangane likhombise intfo leyesindzako. Bhala kumalula noma kuyesindza.

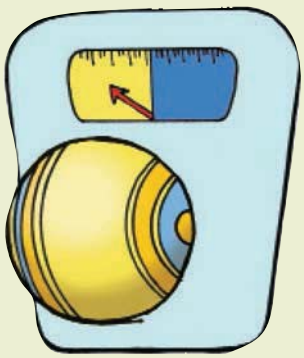

kumalula











Dvweba noma unamatsisele tintfo kuye ngaloko lokukhonjiswa ngulesikali.

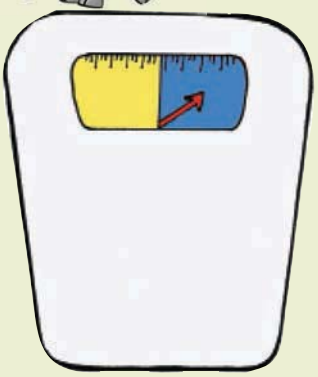

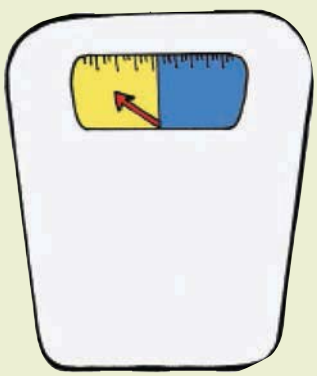

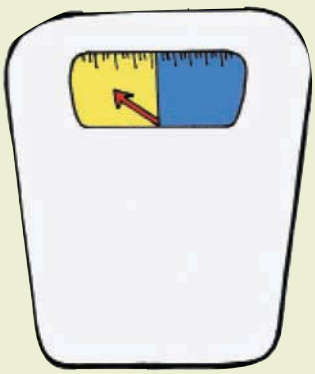

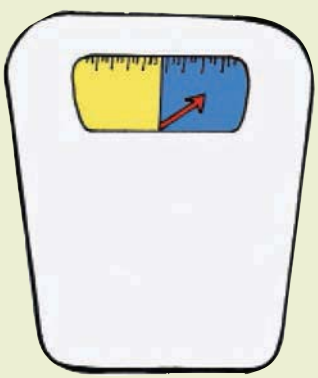

Teacher:
Sign:
Date:

11 12 13 14 15 16 17 18 19 20

Lusuku: _____

Emaphethini etinombolo: ngakubili

1 Asibaleni ngakubili.





2 Dvweba nobe namatsisela tintfo letita ngatimbili.

3 Siyicalile iphethini. Yicedzele.

1	2	3	4	5	6	7	8	9	10
11	12	13	14	15	16	17	18	19	20
21	22	23	24	25	26	27	28	29	30
31	32	33	34	35	36	37	38	39	40
41	42	43	44	45	46	47	48	49	50
51	52	53	54	55	56	57	58	59	60
61	62	63	64	65	66	67	68	69	70
71	72	73	74	75	76	77	78	79	80
81	82	83	84	85	86	87	88	89	90
91	92	93	94	95	96	97	98	99	100



Sebentisa lomugcanombolo kubhala iphethini.

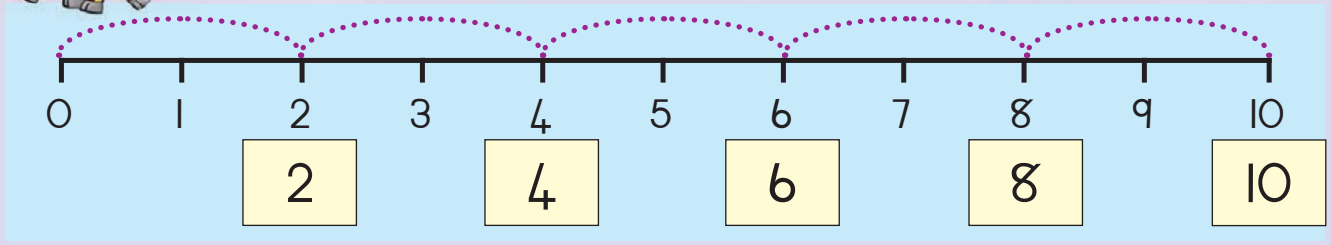

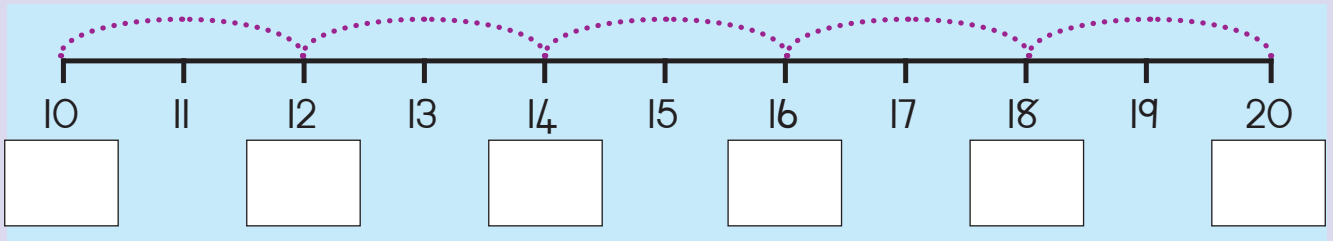

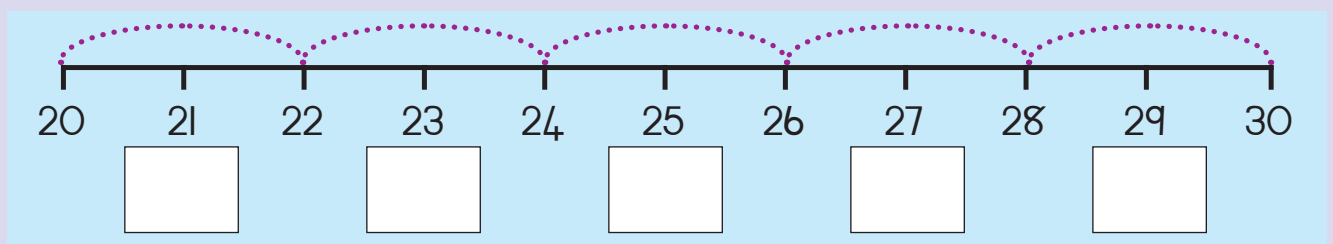

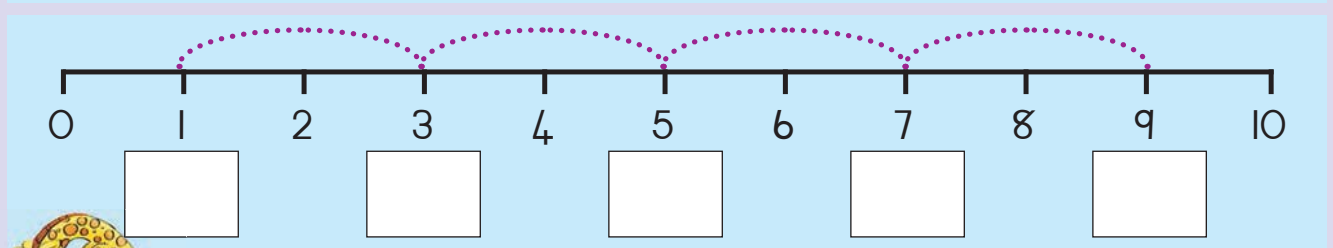

Cedzela loku lokulandzelako.

2, 4, 6, __, __, __	13, 15, 17, __, __, __	26, 24, 22, __, __, __
62, 64, 66, __, __, __	55, 57, 59, __, __, __	9, 7, 5, __, __, __
44, 46, 48, __, __, __	10, 8, 6, __, __, __	29, 27, 25, __, __, __
1, 3, 5, __, __, __	98, 96, 94, __, __, __	95, 93, 91, __, __, __

2 4 6 8 10 12 14 16 18 20

Teacher:
Sign:
Date:

11 12 13 14 15 16 17 18 19 20

Lusuku:

Kuphindza kabili

1 Buka kulithebula lekucala nelesibili. Yini leyentekile?





2 Hlanganisa emacashata, bese ubhala sibalo salokuhlangene.

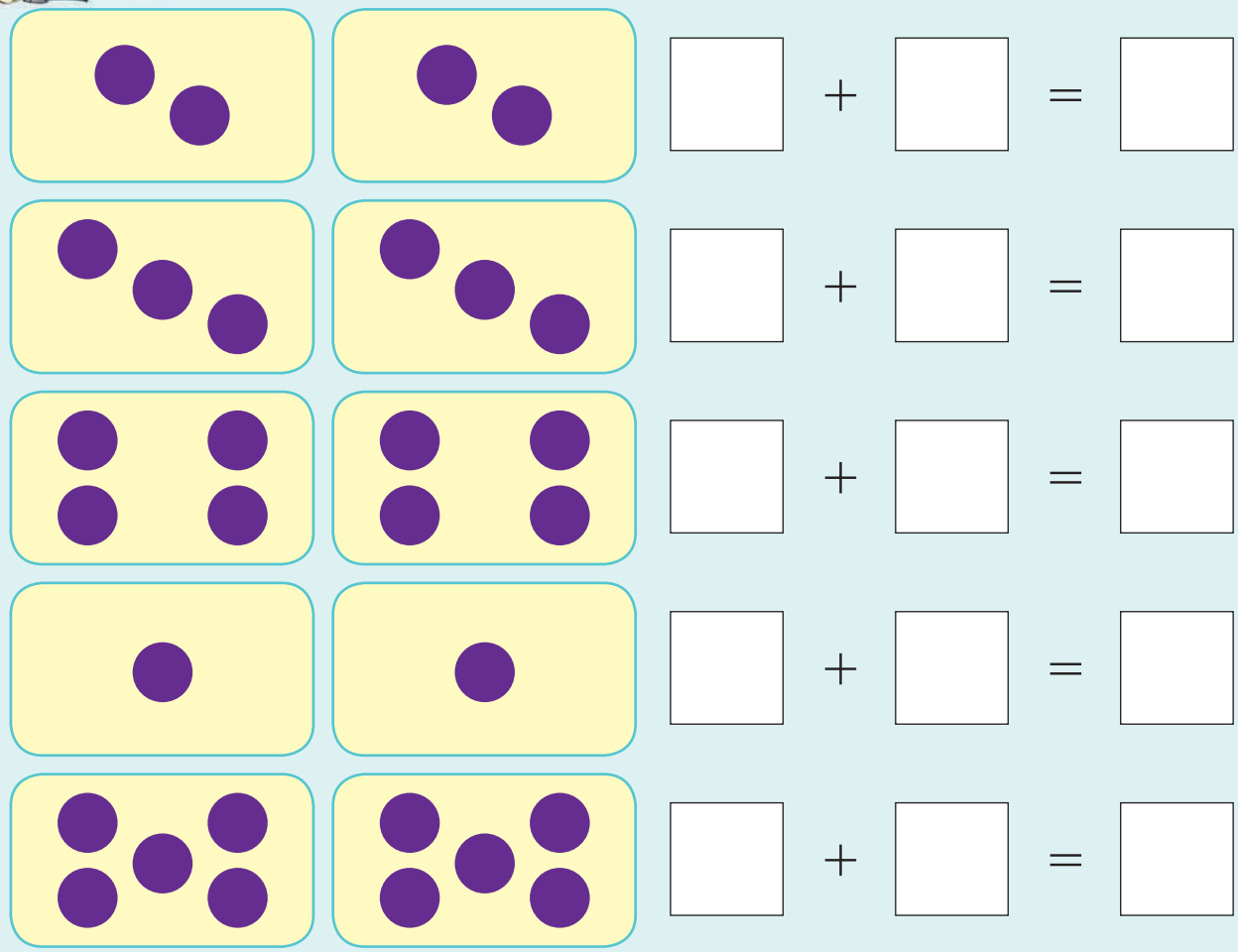



Sebentisa imigcanombolo kubhala sibalo.

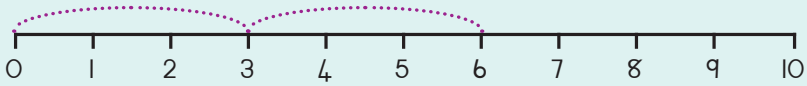

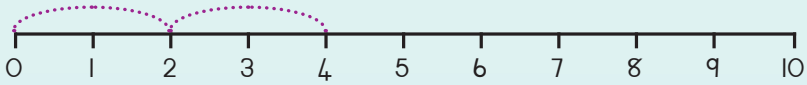



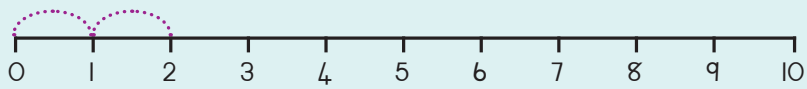

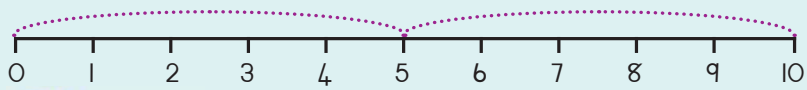

$\square + \square = \square$

$\square + \square = \square$

$\square + \square = \square$

$\square + \square = \square$

$\square + \square = \square$

Phindza loku lokulandzelako.

Phindza kabili 1	1 + 1 = 2	2 × 1 = 2
Phindza kabili 2	□ + □ = □	2 × □ = □
Phindza kabili 3	□ + □ = □	2 × □ = □
Phindza kabili 4	□ + □ = □	2 × □ = □
Phindza kabili 5	□ + □ = □	2 × □ = □

Ngina R5. Umngani wami unalokuphindvwe kabili kulokwami. Umngani wami unamalini?

Teacher:
Sign:
Date:

11 12 13 14 15 16 17 18 19 20

Lusuku:

Phindza kabili futsi

1 Buka kulithebula lekucala nelesibili. Yini leyentekile?



2 Hlanganisa emacashata, bese ubhala sibalo ngasinye.

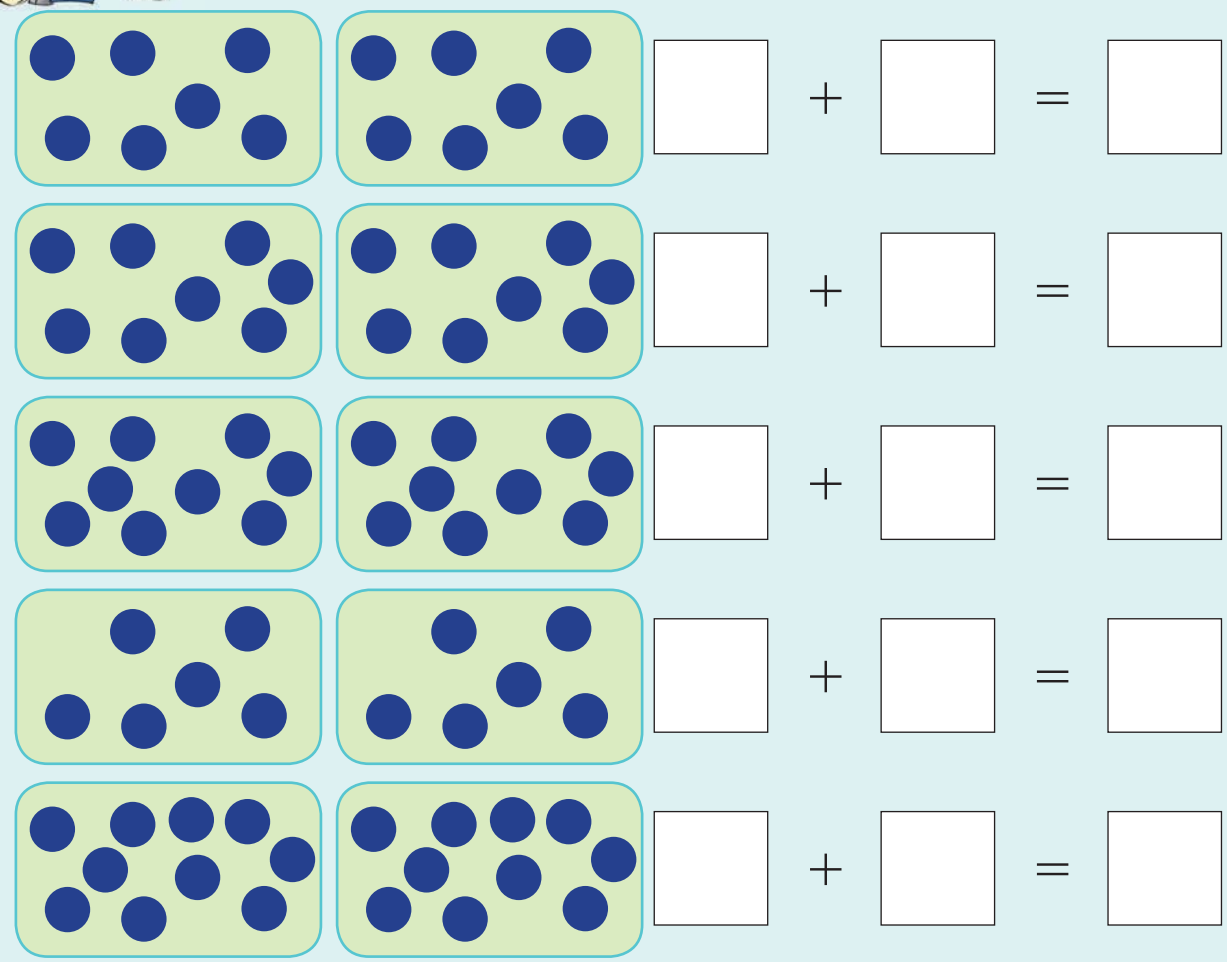



Sebentisa imigcanombolo kubhala sibalo.

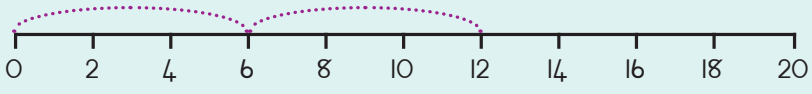

□ + □ = □

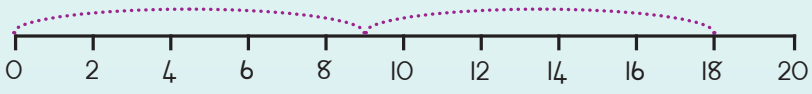

□ + □ = □

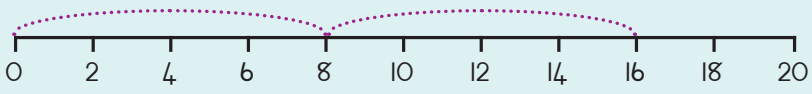

□ + □ = □

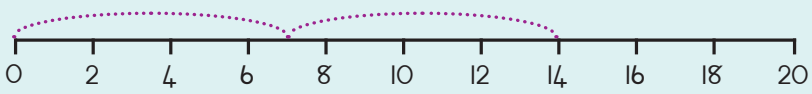

□ + □ = □

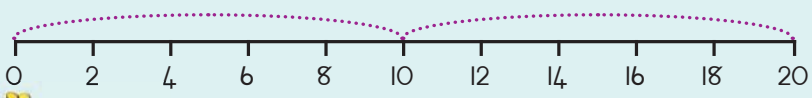

□ + □ = □

Phindza loku lokulandzelako.

Phindza kabili 6

□ + □ = □

2 × 6 = 12

Phindza kabili 7

□ + □ = □

2 × □ = □

Phindza kabili 8

□ + □ = □

2 × □ = □

Phindza kabili 9

□ + □ = □

2 × □ = □

Phindza kabili 10

□ + □ = □

2 × □ = □

Umngani wami unemamabuli langu 9. Ami aphindvwe kabili kulawakhe. Mangakhi emamabuli ami?

Teacher:

Sign:

Date:



Lusuku:

Phindza kabili

Phindza kabili 8

1 2 3 4 5 6 7 8 1 2 3 4 5 6 7 8

1 2 3 4 5 6 7 8 9 10 11 12 13 14 15 16

Phindza kabili 9

1 2 3 4 5 6 7 8 9 1 2 3 4 5 6 7 8 9

1 2 3 4 5 6 7 8 9 10 11 12 13 14 15 16 17 18



Sebentisa lobuhlalu kuphindza kabili tinombolo. Sikucalele loku kwekucala.

Phindza kabili 5



5 + 5 = ☐

Phindza kabili 6



☐ + ☐ = ☐

Phindza kabili 7



☐ + ☐ = ☐

Phindza kabili 8



☐ + ☐ = ☐

Phindza kabili 9



☐ + ☐ = ☐





Phindza kabili letinombolo. Faka umbala kubhuloki yemashumi lasisekelo kukhombisa imphendvulo yakho.

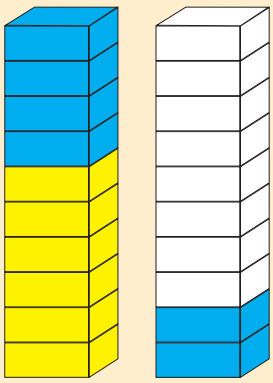

Phindza kabili 6

6 + 6 = ☐

2 × 6 = ☐

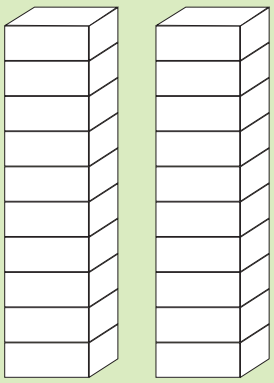

Phindza kabili 8

☐ + ☐ = ☐

2 × ☐ = ☐

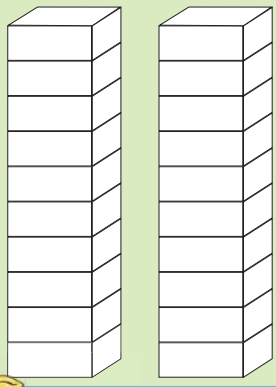

Phindza kabili 7

☐ + ☐ = ☐

2 × ☐ = ☐

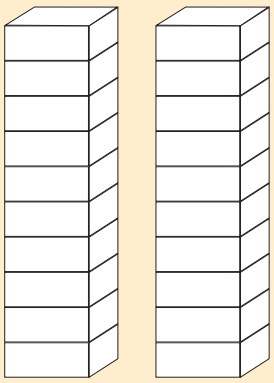

Phindza kabili 9

☐ + ☐ = ☐

2 × ☐ = ☐

Phindza loku lokulandzelako:

Phindza kabili 7	☐ + ☐ = ☐	2 × ☐ = ☐
Phindza kabili 9	☐ + ☐ = ☐	2 × ☐ = ☐
Phindza kabili 6	☐ + ☐ = ☐	2 × ☐ = ☐
Phindza kabili 8	☐ + ☐ = ☐	2 × ☐ = ☐
Phindza kabili 10	☐ + ☐ = ☐	2 × ☐ = ☐

Ngitfole emaphuzu langu 8. Umngani wami utfole laphindvwe kabili kulawami. Unamangakhi emaphuzu umngani wami?

Teacher:

Sign:

Date:



Lusuku:

Phindza kabili: siyachubeka

Phindza kabili 12

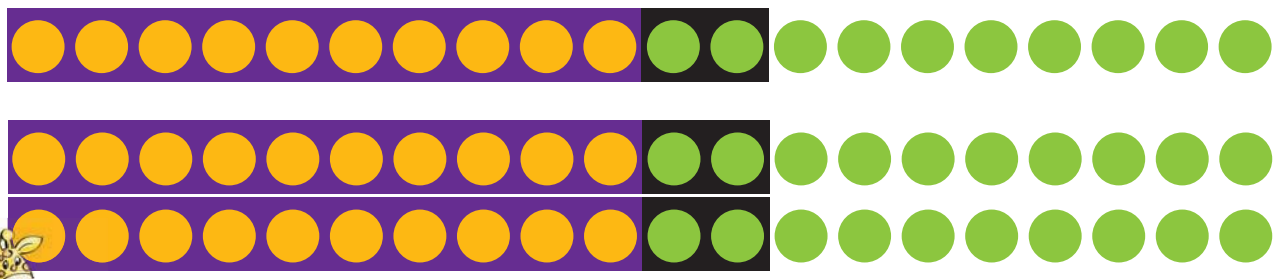



Sebentisa lobuhlalu kuphindza kabili tinombolo. Sikucalele loku kwekucala.

Phindza kabili 13

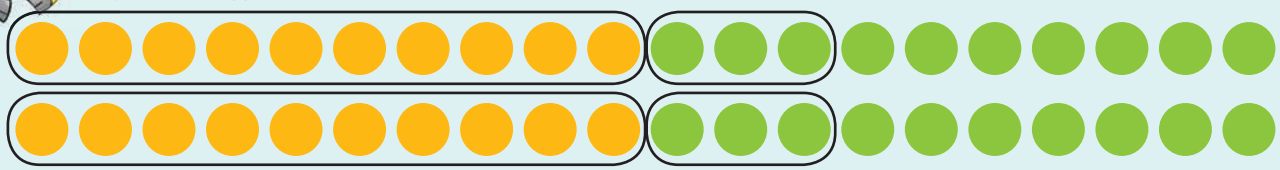

Phindza kabili 15



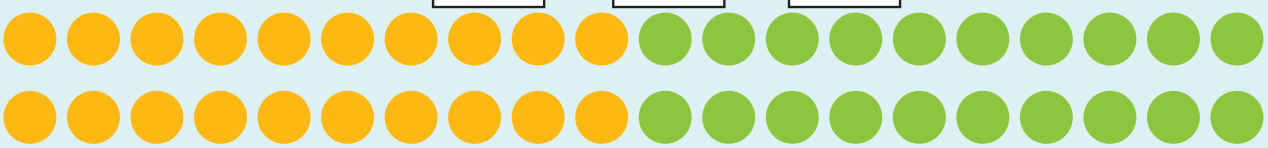

Phindza kabili 14





Phindza kabili 11





Phindza kabili 16









1 2 3 4 5 6 7 8 9 10



Phindza kabili letinombolo. Faka umbala kubhuloki yemashumi lasisekelo kukhombisa imphendvulo yakho.

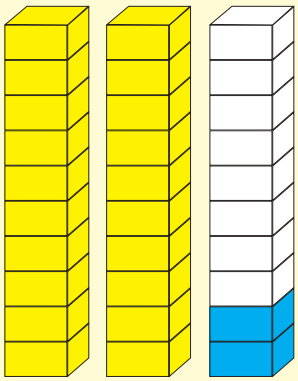

Phindza kabili II

II + II = ☐

2 × II = ☐



Phindza kabili 13

☐ + ☐ = ☐

2 × ☐ = ☐

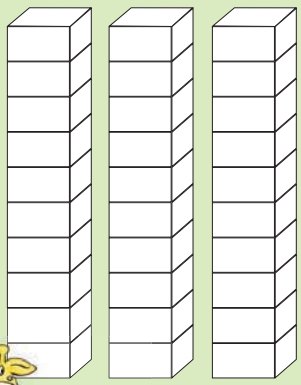

Phindza kabili 14

☐ + ☐ = ☐

2 × ☐ = ☐

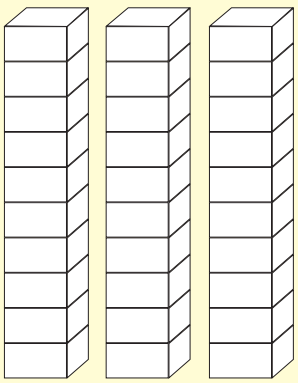

Phindza kabili 15

☐ + ☐ = ☐

2 × ☐ = ☐



Phindza loku lokulandzelako.

Phindza kabili II	☐ + ☐ = ☐	2 × ☐ = ☐
Phindza kabili 13	☐ + ☐ = ☐	2 × ☐ = ☐
Phindza kabili 16	☐ + ☐ = ☐	2 × ☐ = ☐
Phindza kabili 17	☐ + ☐ = ☐	2 × ☐ = ☐
Phindza kabili 18	☐ + ☐ = ☐	2 × ☐ = ☐



Ngidle imicatsane lengu 8. Loncobile udle lephindvwe kabili kuleyami. Loncobile udle mingakhi imicatsane?

Teacher:

Sign:

Date:



Lusuku:

Kwekuphatsa nemtsamo

1 Coca ngekwekuphatsa etukwemadesiki.



2 Shano kutsi kwekuphatsa kugcwele noma kute lutfo.





Faka umbala kulokusamanti kuletintfo tekuphatsa.

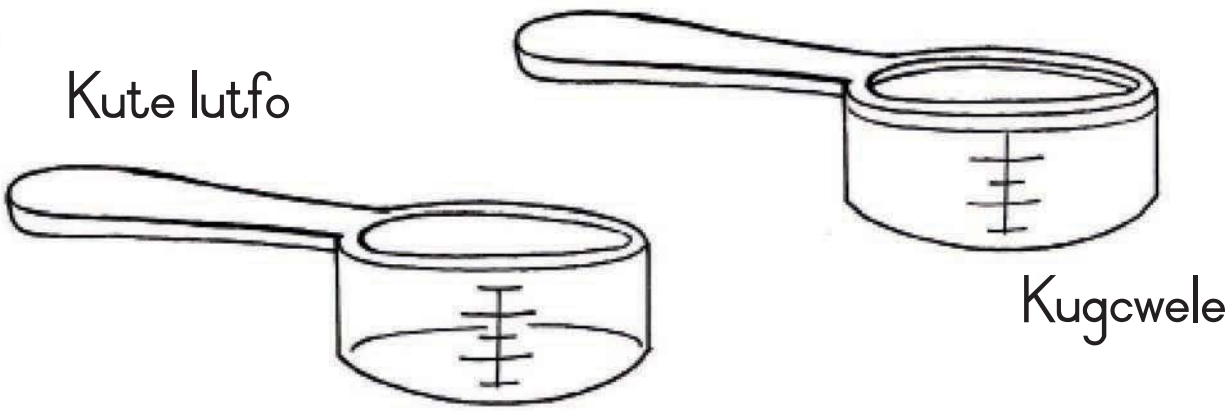



Dvweba takakho tintfo tekuphatsa bese ufaka umbala kuletikucuketse.

kute lutfo	kugcwele
kute lutfo	kugcwele

Teacher:
Sign:
Date:

Lusuku:

Kuphindzaphindza: x 3

1 Mangakhi emaswidi lakhona esibayeni ngasinye?

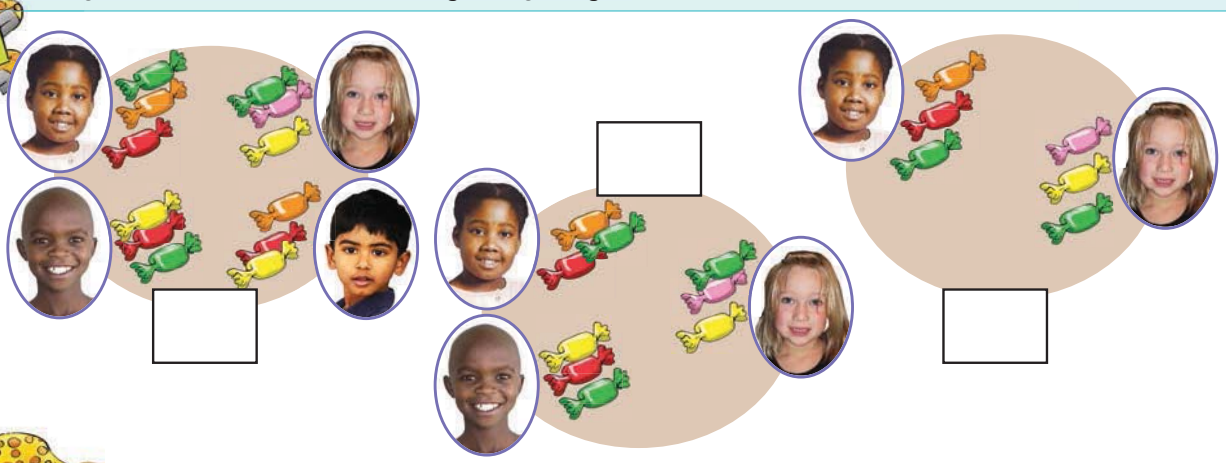

2 Cedzela loku lokulandzelako:

2 emacembu a 3	3 + 3 =	3 × 2 =
3 emacembu a 3	3 + 3 + 3 =	3 × 3 =
4 emacembu a 3	3 + 3 + 3 + 3 =	3 × 4 =
6 emacembu a 3	3 + 3 + 3 + 3 + 3 + 3 =	3 × 6 =
7 emacembu a 3	3 + 3 + 3 + 3 + 3 + 3 + 3 =	3 × 7 =

3 Yenta umdvwebo waloku lokulandzelako.

3 emacembu a 3	4 emacembu a 3	5 emacembu a 3



Yenta umdvwebo waloku lokulandzelako.

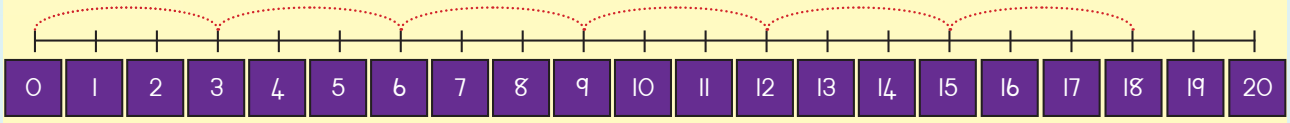

3, 6, 9, 12, ___ , ___

3 + 3 + 3 + 3 + 3 + 3= ☐

6 × 3 = ☐

Umdvwebo

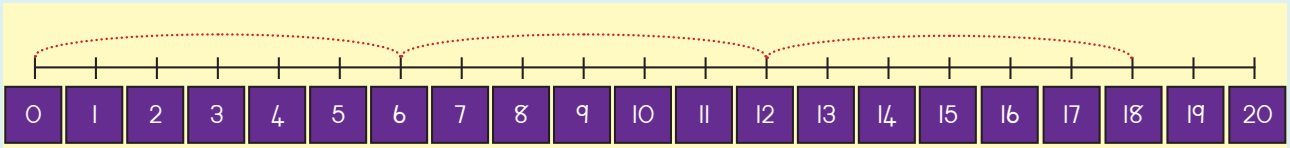

6, ___ , ___

6 + ☐ + ☐ = ☐

3 × ☐ = ☐

Umdvwebo



Libhodo lekupheka linetinyawo letintsatfu. Ngabe emabhodo ekupheka lasi 7 anetinyawo letingakhi?

☐





3 6 9 12 15 18

21 24 27 30 33

Teacher:

Sign:

Date:



11 12 13 14 15 16 17 18 19 20

Lusuku:

Emaphethini etinombolo: ngakutsatfu





Dvweba nobe namatsisela titfombe tetintfo letita ngatintsatfu.

Siyicalile iphethini. Yicedzele.

1	2	3	4	5	6	7	8	9	10
11	12	13	14	15	16	17	18	19	20
21	22	23	24	25	26	27	28	29	30
31	32	33	34	35	36	37	38	39	40
41	42	43	44	45	46	47	48	49	50
51	52	53	54	55	56	57	58	59	60
61	62	63	64	65	66	67	68	69	70
71	72	73	74	75	76	77	78	79	80
81	82	83	84	85	86	87	88	89	90
91	92	93	94	95	96	97	98	99	100



Sebentisa lomugcanombolo kubhala iphethini.

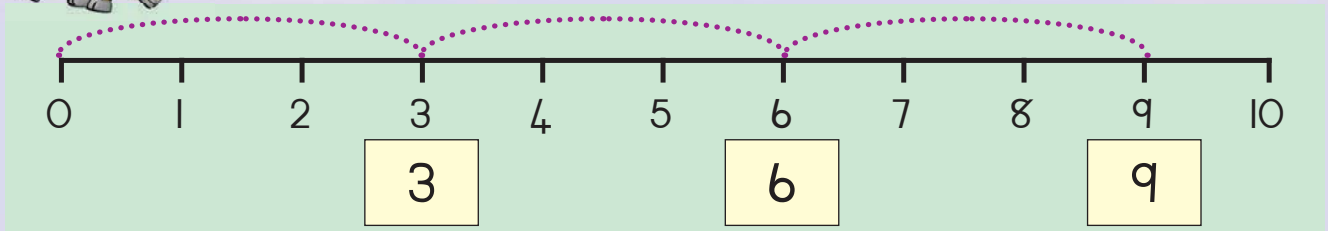

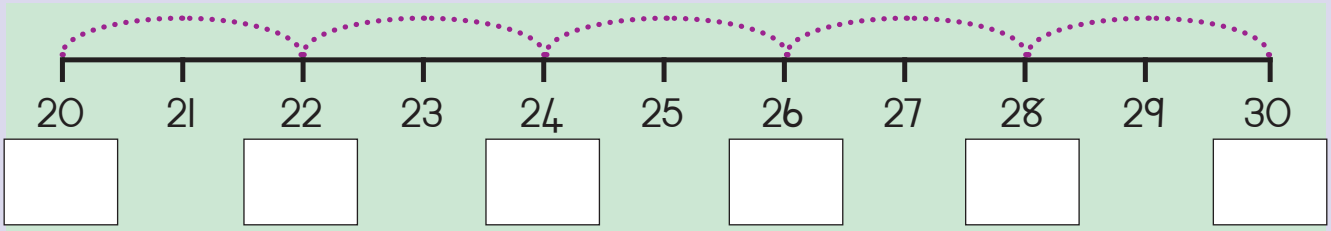

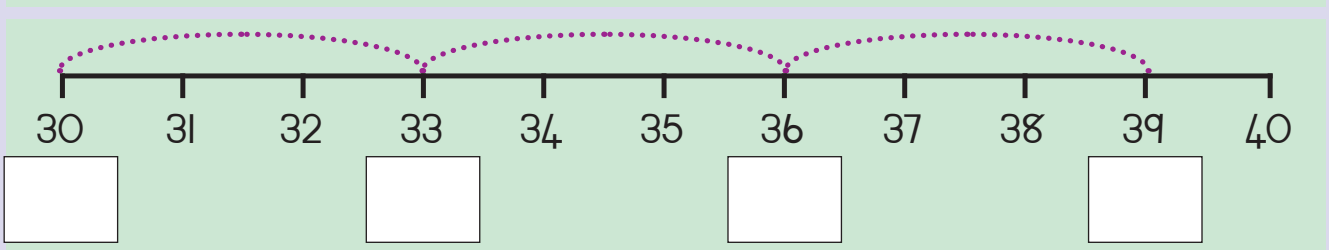

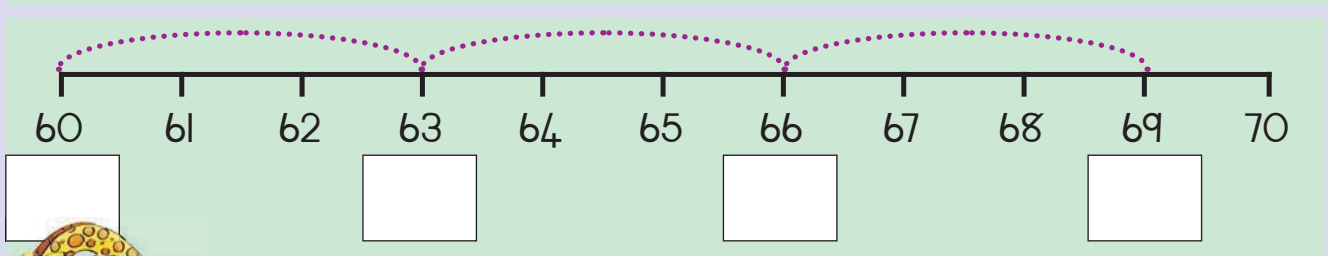



Cedzela loku lokulandzelako.

3, 6, 9, __ , __ , __	1, 4, 7, __ , __ , __	99, 96, 93, __ , __ , __
36, 39, 42, __ , __ , __	22, 25, 28, __ , __ , __	66, 63, 60, __ , __ , __
12, 15, 18, __ , __ , __	15, 12, 9, __ , __ , __	40, 37, 34, __ , __ , __



Kunabosondvo-ntsatfu labali-10 enkhulisa. Mangakhi emasondvo alabosondvo-ntsatfu lataba khona?

Teacher:
Sign:
Date:



Lusuku:

Kuphindzaphindza: x 4

1 Mangakhi emaswidi lakhona esibayeni ngasinye?



2 Cedzela loku lokulandzelako.

3 emacembu a 4	4 + 4 + 4 =	3 × 4 = ☐
2 emacembu a 4	4 + 4 =	2 × 4 = ☐
4 emacembu a 4	4 + 4 + 4 + 4 =	4 × 4 = ☐
6 emacembu a 4	4 + 4 + 4 + 4 + 4 + 4 =	6 × 4 = ☐
7 emacembu a 4	4 + 4 + 4 + 4 + 4 + 4 + 4 =	7 × 4 = ☐

3 Yenta umdvwebo waloku lokulandzelako.

3 emacembu a 4	4 emacembu a 4	5 emacembu a 4



Yenta umdvwebo waloku lokulandzelako.

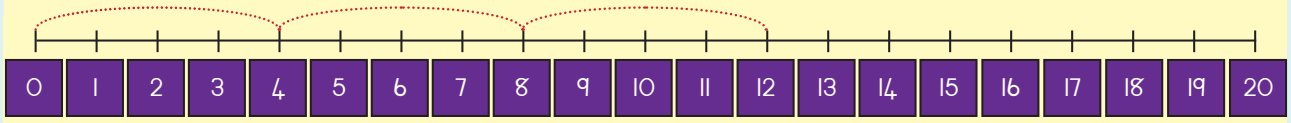

4, 8, ___

$4 + 4 + 4 =$ ☐

$4 \times 3 =$ ☐

Umdvwebo



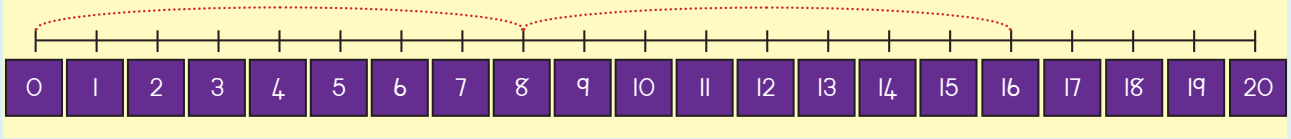

8, ___

$8 +$ ☐ $=$ ☐

$8 \times$ ☐ $=$ ☐

Umdvwebo



Lihhashi linetinyawo leti 4. Ngabe emahhashi lama 3 anetinyawo letingakhi?

☐



4 8 12 16 20 24

28 32 36 40

Teacher:

Sign:

Date:



Lusuku:

Emaphethini etinombolo: Ngakune

1 Asibaleni ngakune.





2 Dvweba nobe namatsisela titfombe tetintfo letita ngatine.

3 Siyicalile iphethini. Yicedzele.

1	2	3	4	5	6	7	8	9	10
11	12	13	14	15	16	17	18	19	20
21	22	23	24	25	26	27	28	29	30
31	32	33	34	35	36	37	38	39	40
41	42	43	44	45	46	47	48	49	50
51	52	53	54	55	56	57	58	59	60
61	62	63	64	65	66	67	68	69	70
71	72	73	74	75	76	77	78	79	80
81	82	83	84	85	86	87	88	89	90
91	92	93	94	95	96	97	98	99	100



Sebentisa lomugcanombolo kubhala iphethini.

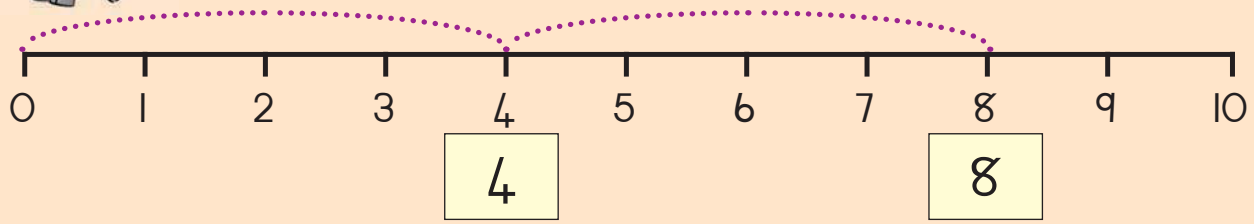

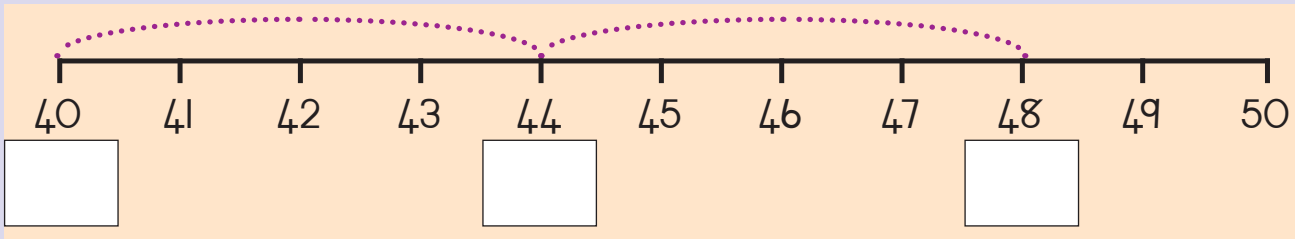

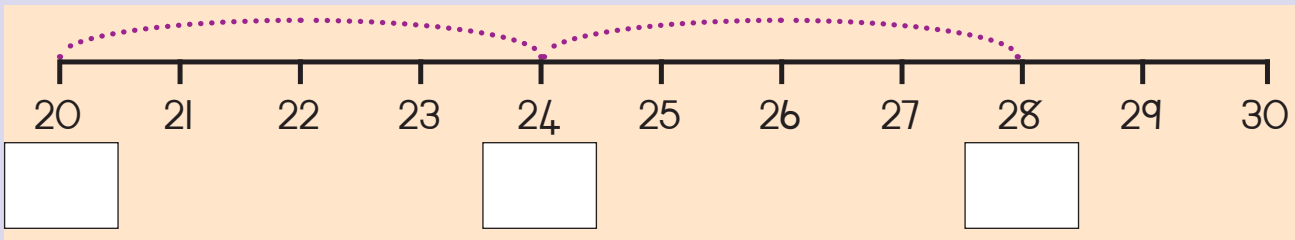

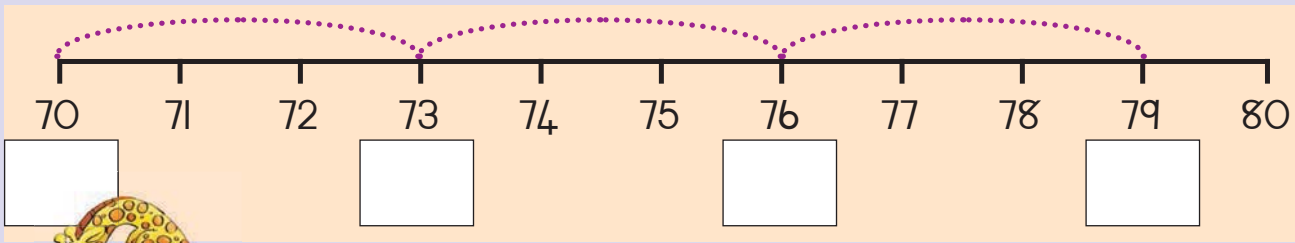



Cedzela loku lokulandzelako.

4, 8, 12, __ , __ , __	1, 5, 9, __ , __ , __	48, 44, 40, __ , __ , __
28, 32, 36, __ , __ , __	42, 46, 50, __ , __ , __	60, 56, 52, __ , __ , __
12, 16, 20, __ , __ , __	20, 16, 12, __ , __ , __	70, 66, 62, __ , __ , __



Kunemicatsane lengu 4 aphaketheni. Ngitsengise emaphakethe langu 9.
Mingakhi imicatsane lengiyitsengisile?

Teacher:
Sign:
Date:



Lusuku:

Tindzaba tekuphindzaphindza

Yenta indzaba yakho usebentise emagama lafana nemehlo, imilente, tandla tinyawo, tilwane, bantfu. Yengeta inombolo kukunye.



Likati linemehlo langu 2. Emakati langu 4 anamangakhi emehlo?

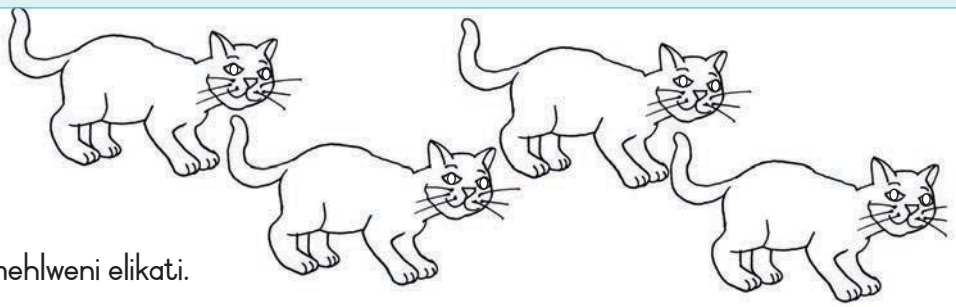

Faka umbala emehlweni elikati.

Wakhombise ngetintfo tekubala.

Wakhombise kumugcanombolo.

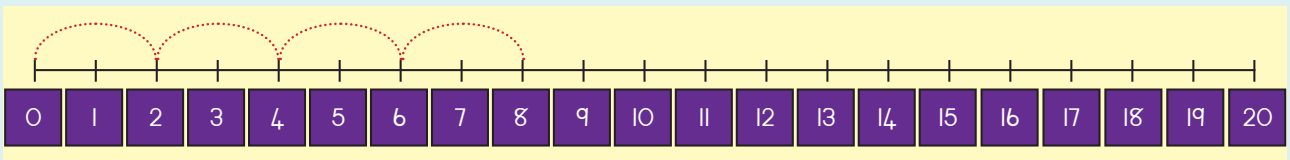

□ + □ + □ + □ = □

□ × □ = □

Libhayisikili linemasondvo langu 3. Ngabe emabhayisikili emasondvo lamatsatfu langu 5 anemasondvo lamangakhi?



Faka umbala emasondvweni.

Khombisa ngetintfo tekubala.

Khombisa kumugcanombolo.

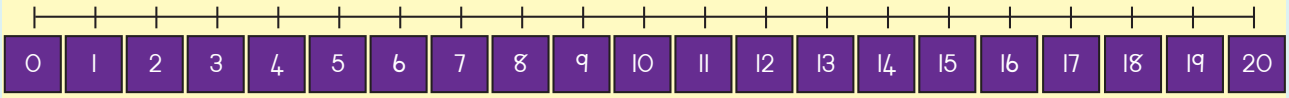

____ + ____ = ____ ____ × ____ = ____

Inja inetinyawo letingu 4. Ngabe tinja letingu 4 tinetinyawo letingakhi?

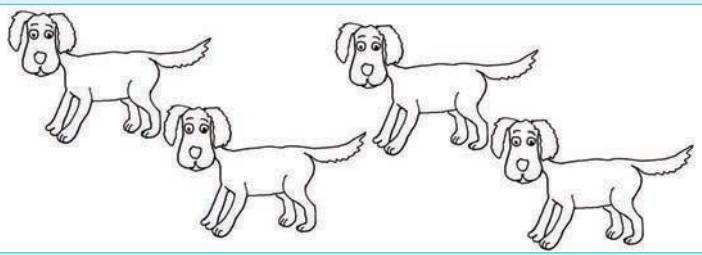

Hlobisa letinja

Khombisa ngetintfo tekubala.

Khombisa kumugcanombolo.

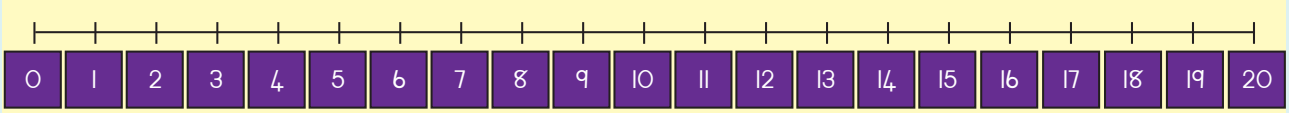

____ + ____ = ____ ____ × ____ = ____

Teacher:
Sign:
Date:

Lusuku:

Ema – awa

1 Coca ngeliwashi.



Lutsi lolufisha lusikhombisa ema-awa.
Lapha lusikhombisa 7 wema-awa.

Lutsi ewashini luhamba lugegelete futsi lugegelete, Lugegelete futsi lugegelete, lugegelete futsi lugegelete. Lutsi ewashini luhamba lugegelete futsi lugegelete, Kusatisa sikhatsi.

2 Lutsi lolufisha lusikhombisani?



li-awa



ema-awa

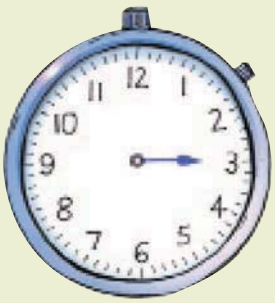

ema-awa



ema-awa



ema-awa



ema-awa



ema-awa



ema-awa



ema-awa



ema-awa



ema-awa



ema-awa



Dvweba lutsi lolufisha.

4 ema-awa



I li-awa



II ema-awa



7 ema-awa



9 ema-awa



IO ema-awa



2 ema-awa



5 ema-awa



3 ema-awa



6 ema-awa



8 ema-awa



I2 ema-awa





Yini lengatsatsa li-awa? Faka umbala emphendvulweni lengiyo.



Wenta umsebenti wesikolo ekhaya



Ulele



Ucubha ematinyo

Teacher:

Sign:

Date:

Lusuku: _____

Emaphethini etinombolo: ngesihlanu

1 Asibaleni ngesihlanu.





2 Dvweba nobe namatsisela titfombe tetintfo letita ngatinhlanu.

3 Siyicalile iphethini. Yicedzele.

1	2	3	4	5	6	7	8	9	10
11	12	13	14	15	16	17	18	19	20
21	22	23	24	25	26	27	28	29	30
31	32	33	34	35	36	37	38	39	40
41	42	43	44	45	46	47	48	49	50
51	52	53	54	55	56	57	58	59	60
61	62	63	64	65	66	67	68	69	70
71	72	73	74	75	76	77	78	79	80
81	82	83	84	85	86	87	88	89	90
91	92	93	94	95	96	97	98	99	100



Sebentisa lomugcanombolo kubhala iphethini.

0 1 2 3 4 5 6 7 8 9 10

0 5 10

40 41 42 43 44 45 46 47 48 49 50

21 22 23 24 25 26 27 28 29 30 31

70 71 72 73 74 75 76 77 78 79 80

Cedzela loku lokulandzelako.

5, 10, 15, __, __, __	1, 6, 11, __, __, __	50, 45, 40, __, __, __
20, 25, 30, __, __, __	23, 28, 33, __, __, __	60, 55, 50, __, __, __
30, 35, 40, __, __, __	25, 20, 15, __, __, __	54, 49, 44, __, __, __

5 10 15 20 25 30 35 40 45 50

Teacher:
Sign:
Date:

11 12 13 14 15 16 17 18 19 20

Lusuku:

Imizuzu

1 Iyini lemigca lemifisha lentima ewashini?





Cabanga tonkhe tintfo longatenta ngemzuzu munye.

2 Gcwalisa lemizuzu.



3 Bhala phansi letinombolo letisetikweleni letibovu lapha.



Yenta umdvwebo wetintfo longatenta ngalesikhatsi ...

1 umzuzu	5 wemizuzu
30 wemizuzu	60 wemizuzu

Teacher:

Sign:

Date:

Lusuku:

Siyachubeka ngemizuzu

Coca ngeliwashi.



Lutsi loludze lusikhombisa imizuzu.
Lapha lusikhombisa 10 wemizuzu.

Lutsi ewashini luhamba lugegelete futsi lugegelete, Lugegelete futsi lugegelete, lugegelete futsi lugegelete. Lutsi ewashini luhamba lugegelete futsi lugegelete.
Kusatisa sikhatsi.

2 Ngabe lutsi loludze lusikhombisani?



imizuzu



imizuzu



imizuzu



imizuzu



imizuzu



imizuzu

Dvweba lutsi loludze.

55 imizuzu



35 imizuzu



60 imizuzu



10 imizuzu



45 imizuzu



12 imizuzu



Yini lengatsatsa umzuzu munye? Faka umbala emphendvulweni lengiyo.



Uyazuba



Uyadlala



Uyadla

Teacher:

Sign:

Date:

11 12 13 14 15 16 17 18 19 20

Lusuku:

Kubeka ngemacembu nekwabelana

1 Mangaki emabhuloki kundilinga ngayinye? Wabe emkhatsini webantfwana.



2 Mangakhi emabhuloki kundilinga ngayinye? Bhala ithothali kundingilizi leluhlata sasibhakabhaka.

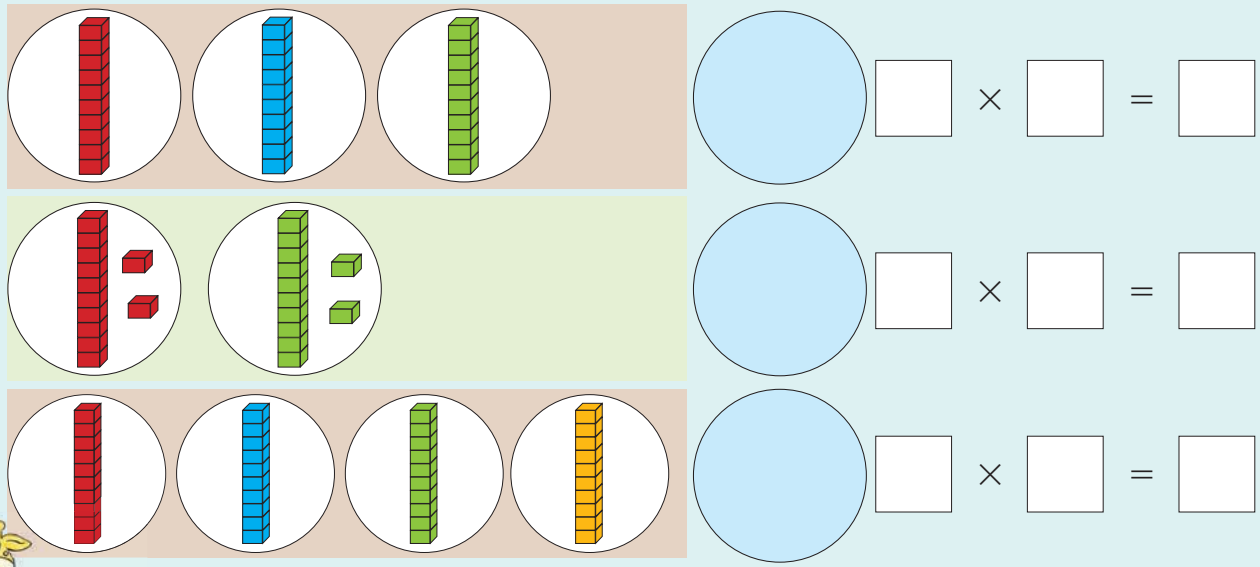

3 Yaba emabhuloki emkhatsini wetindilinga.

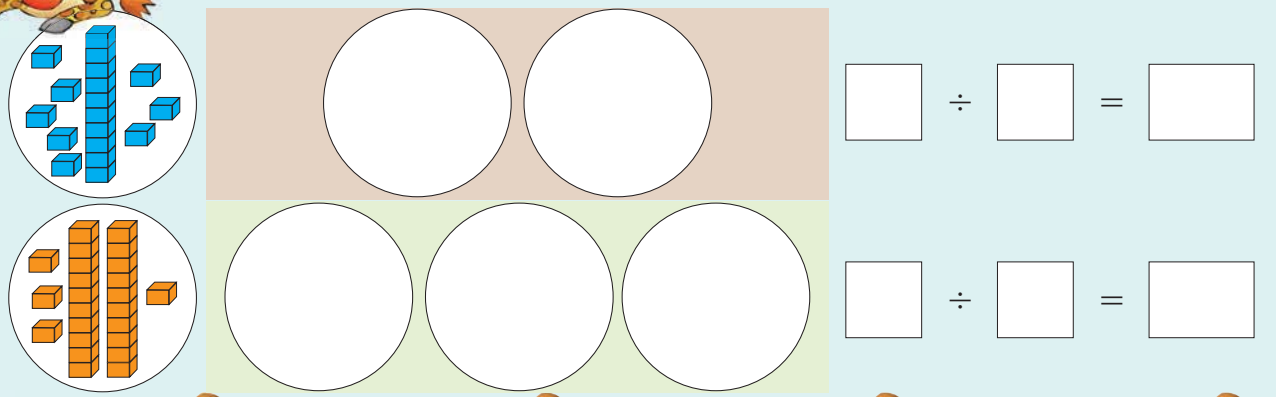



Dvweba loku lokulandzelako. Bhala sibalo sakunye.

3 emacembu a 2

+ Sibalo sekuhlanganisa:

× Sibalo sekuphindzaphindza:

2 emacembu a 25

+ Sibalo sekuhlanganisa:

× Sibalo sekuphindzaphindza:

Yaba tintfo tekubala letingu 12 emakhatsini kwa 4.

− Sibalo sekukhipha:

÷ Sibalo sekuhlukanisa:

Yaba tintfo tekubala letingu 36 emakhatsini kwa 3.

− Sibalo sekukhipha:

÷ Sibalo sekuhlukanisa:

Kubala.

2 emacembu a 7 _____ 3 emacembu a 8 _____

4 emacembu a 5 _____ 2 emacembu a 15 _____

Yaba 18 nga 2 _____ Yaba 24 nga 3 _____

Yaba 35 nga 5 _____ Yaba 50 nga 10 _____

Bekunemacembu langu 6 abo 5 edzilini lami. Bebabangakhi labantfwana kulelidzili lami?

Teacher:

Sign:

Date:

11 12 13 14 15 16 17 18 19 20

Lusuku:

Kubutsanisa nekwabelana

1 Mangakhi emabhuloki kundilinga ngayinye? Wabe emkhatsini webantfwana.



2 Tingakhi tintfo tekubala kundilinga ngayinye?
Bhala ithothali kundilinga leluhlata sasibhakabhaka.

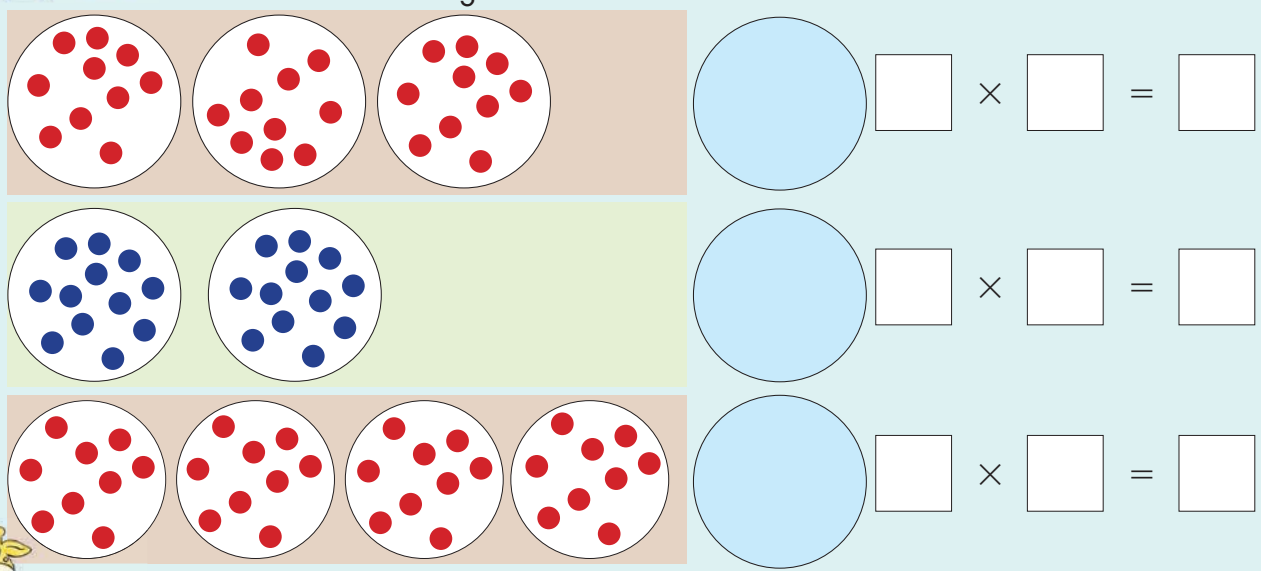

3 Hlukanisa letintfo tekubala emkhatsini wetindilinga.

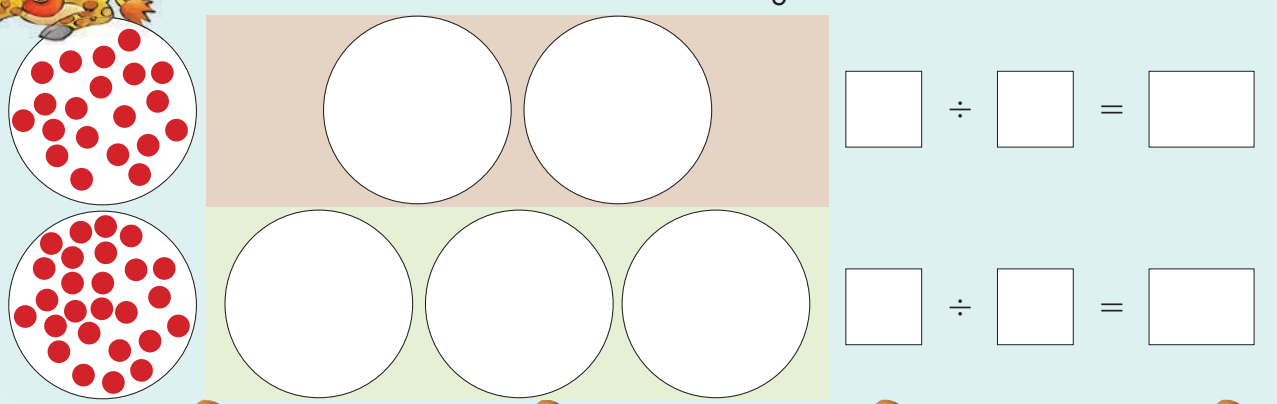



Dvweba loku lokulandzelako. Bhala sibalo sakunye.

3 emacembu a 12

+ Sibalo sekuhlanganisa:

× Sibalo sekuphindzaphindza:

5 emacembu a 10

+ Sibalo sekuhlanganisa:

× Sibalo sekuphindzaphindza:

Yaba tintfo tekubala letingu 24 emkhatsini kwa 4

− Sibalo sekukhipha:

÷ Sibalo sekuhlukanisa:

Yaba tintfo tekubala letingu 25 emkhatsini kwa 5.

− Sibalo sekukhipha:

÷ Sibalo sekuhlukanisa:



Kubala.

2 emacembu a 11 _____	3 emacembu a 10 _____
4 emacembu a 4 _____	2 emacembu a 25 _____
Yaba 20 nga 2 _____	Yaba 27 nga 3 _____
Yaba 50 nga 5 _____	Yaba 28 nga 2 _____



Kuphindza kabili

Teacher:
Sign:
Date:



11 12 13 14 15 16 17 18 19 20

Lusuku:

Kubutsanisa nekwabelana

1 Tingakhi tintfo tekubala kundilinga ngayinye? Tabele bantfwana lababili.



2 Tingakhi tintfo tekubala kundilinga ngayinye?

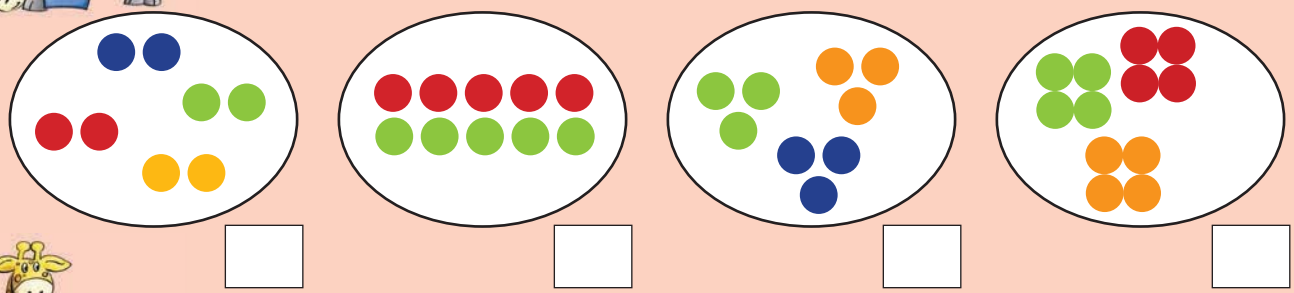

3 Juba bobunjwa kuLokujutjiwe 4 bese ubanamatsisela kubhuloki lefanele. Bala bobunjwa.

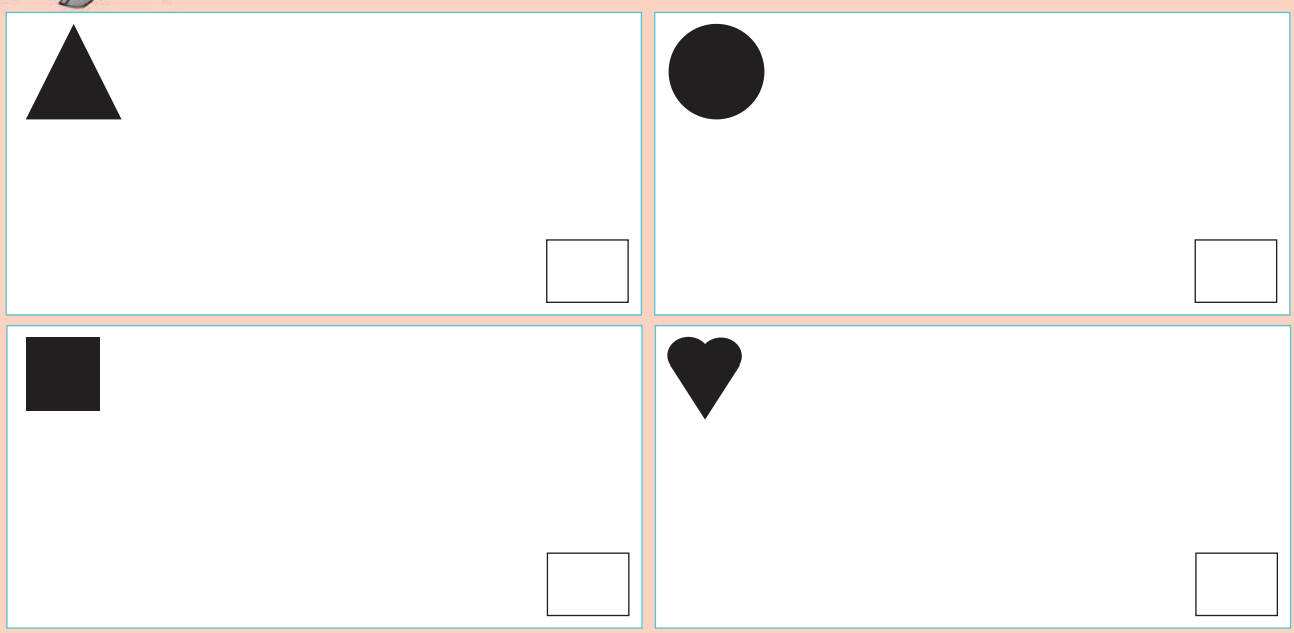





Yabela bantfwana labobunjwa. Sebentisa labobunjwa kuLokujutjiwe 4.

bocalantsatfu





tikwele











Yabela bantfwana lesitselo. Sidvwebe.





bocalantsatfu





tikwele











BoJohn naBelinda babelane 12 wemaswidi ngalokulinganako. Amunye utfole mangakhi?

Teacher:

Sign:

Date:



Lusuku:

Kubutsanisa nekwabelana

1 Bungaki buhlalu lobubalako kundilinga ngayinye? Babele bantfwana.



2 Bungakhi buhlalu kundilinga ngayinye?

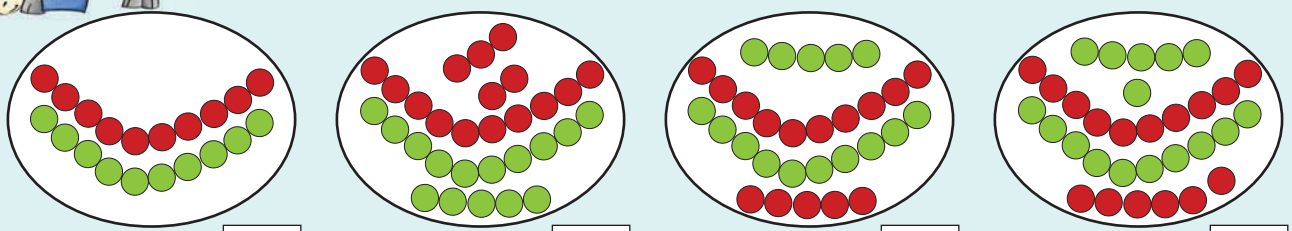

3 Juba lobuhlalu kuLokujutjiwe 4 bese ubunamatsisela lapha. Bala lobuhlalu.

Buhlalu lobubovu	Buhlalu lobulingangane
Buhlalu lobuliphuti	Buhlalu lobuluhlata



4 Dvweba linani lelilinganako lebuhlalu bemntfwana ngamunye.






5 Yaba lobuhlalu wabele bantfwana. Budvwebe.

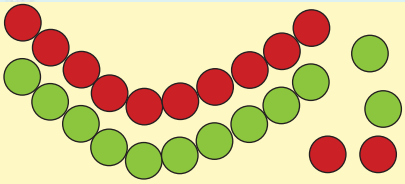
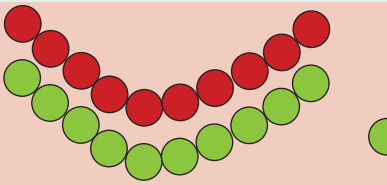







6 Busi naZaheda babelane 32 wemapeniseli lanemibala ngalokulinganako. Amunye utfole mangakhi?

Teacher:
Sign:
Date:

Lusuku:

Bohhafu: 1–20

Yini leyentekile kumahhabhula?



Yaba titselo letingesancele emabhasikidini langesekudla. Tidvwebe.

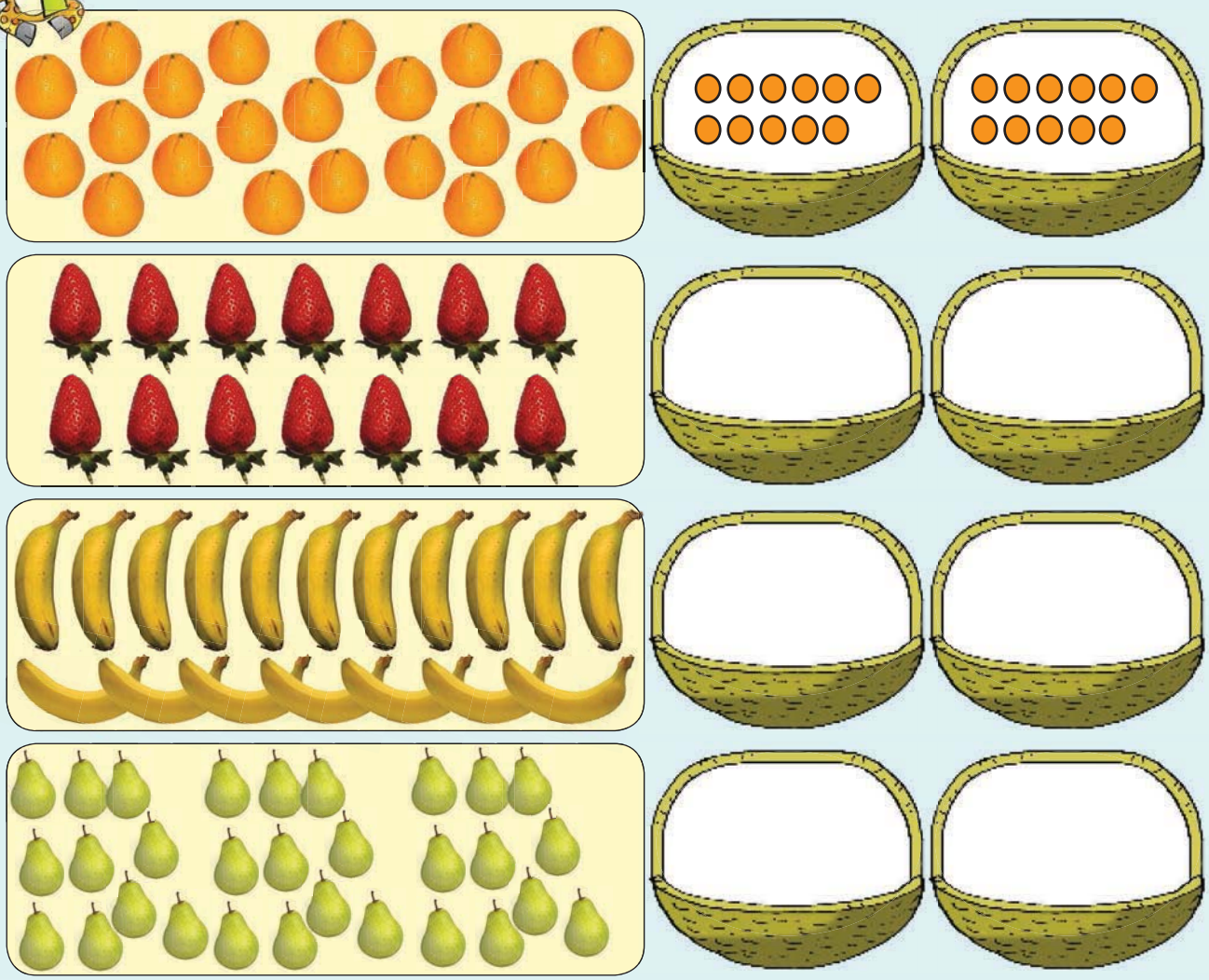

1 2 3 4 5 6 7 8 9 10



2 Dvweba umugca kukhombisa ihhafu.

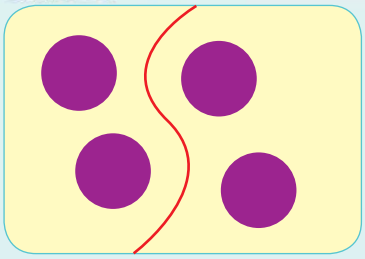

Ihhafu ya 4 ngu 2



Ihhafu ya 6 ngu



Ihhafu ya 8 ngu



Ihhafu ya 2 ngu

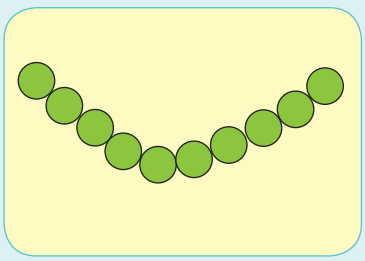

Ihhafu ya 10 ngu

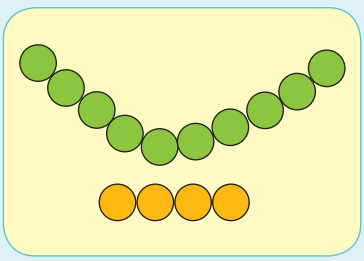

Ihhafu ya 14 ngu

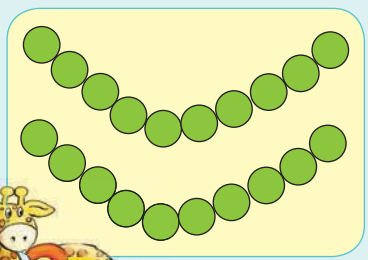

Ihhafu ya 20 ngu

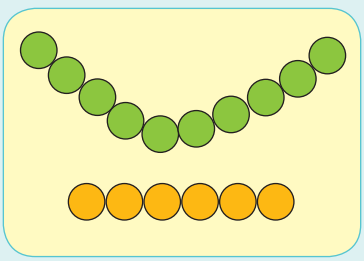

Ihhafu ya 16 ngu

3 Yini ihhafu yelipulede ngalinye lekudla?



Teacher:

Sign:

Date:

Lusuku:

Kwabelana 20–50





Tjela umngani wakho kutsi lobuhlalu babiwe njani.







Yaba lobuhlalu lobungesancele emabhasikidini langesekudla ngalokulinganako. Budvwebe.

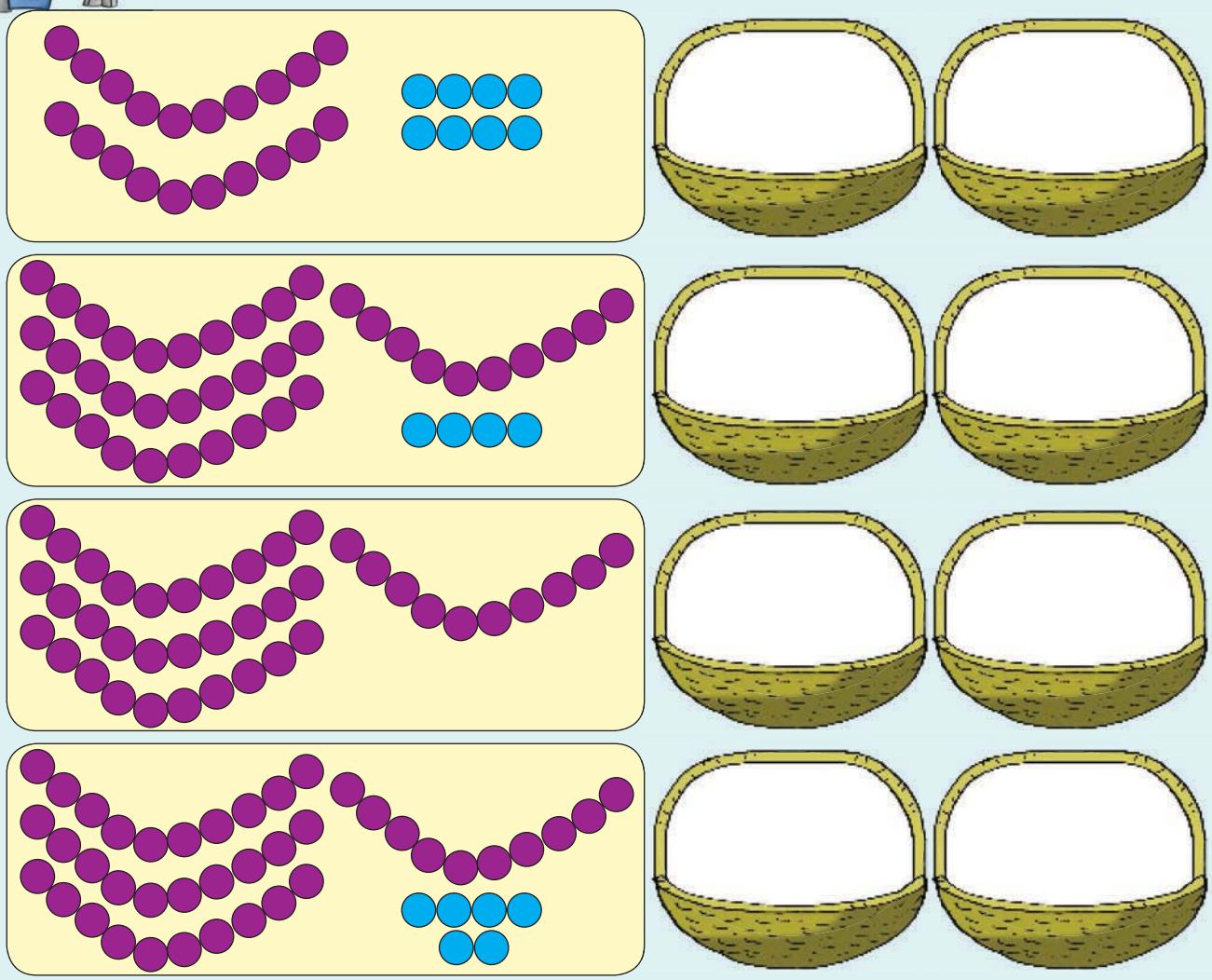





Faka umbala lohlukile ehhafini yaloku.

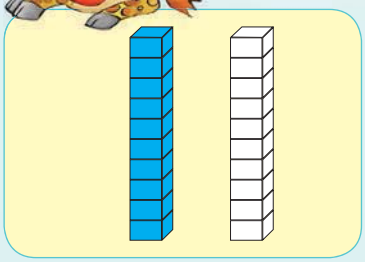

Ihhafu ya 20 ngu 10

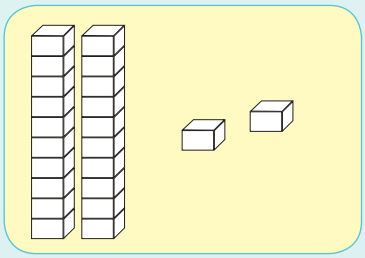

Ihhafu ya 22 ngu

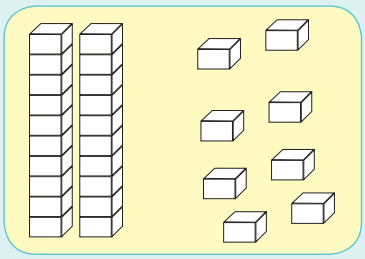

Ihhafu ya 28 ngu

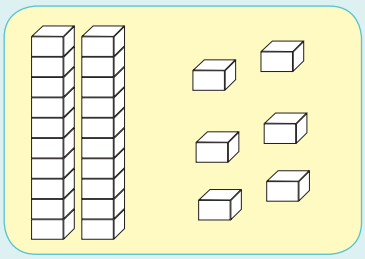

Ihhafu ya 26 ngu

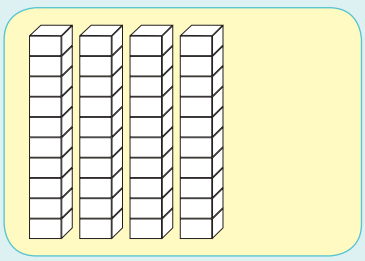

Ihhafu ya 40 ngu

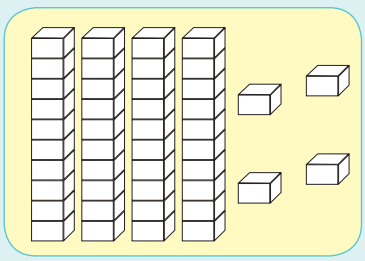

Ihhafu ya 44 ngu

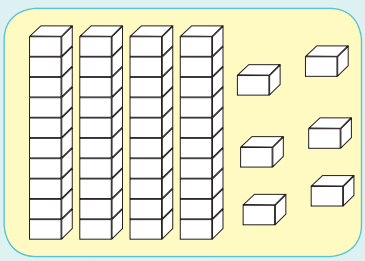

Ihhafu ya 46 ngu

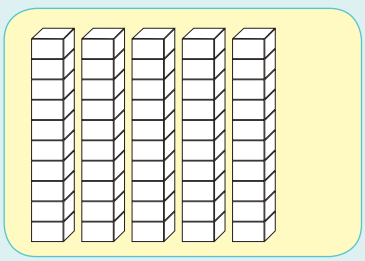

Ihhafu ya 50 ngu



Faka umbala kudayagramu ngayinye.

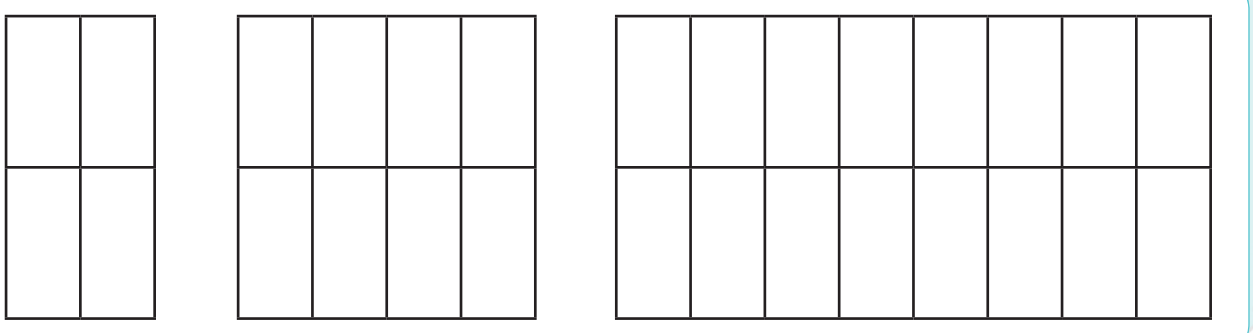



Teacher:

Sign:

Date:





Lusuku:

Imininingwane



Hlunga letitselo. Yenta wakakho umdvwebo kukhomba loku. Bhala samba (ithothali) ebhokisini.



Ngekuhlunga ngibeka titselo letifanako ndzawonye.



Lokujutjiwe 1

Lishadi lekusebentela 10 na 40

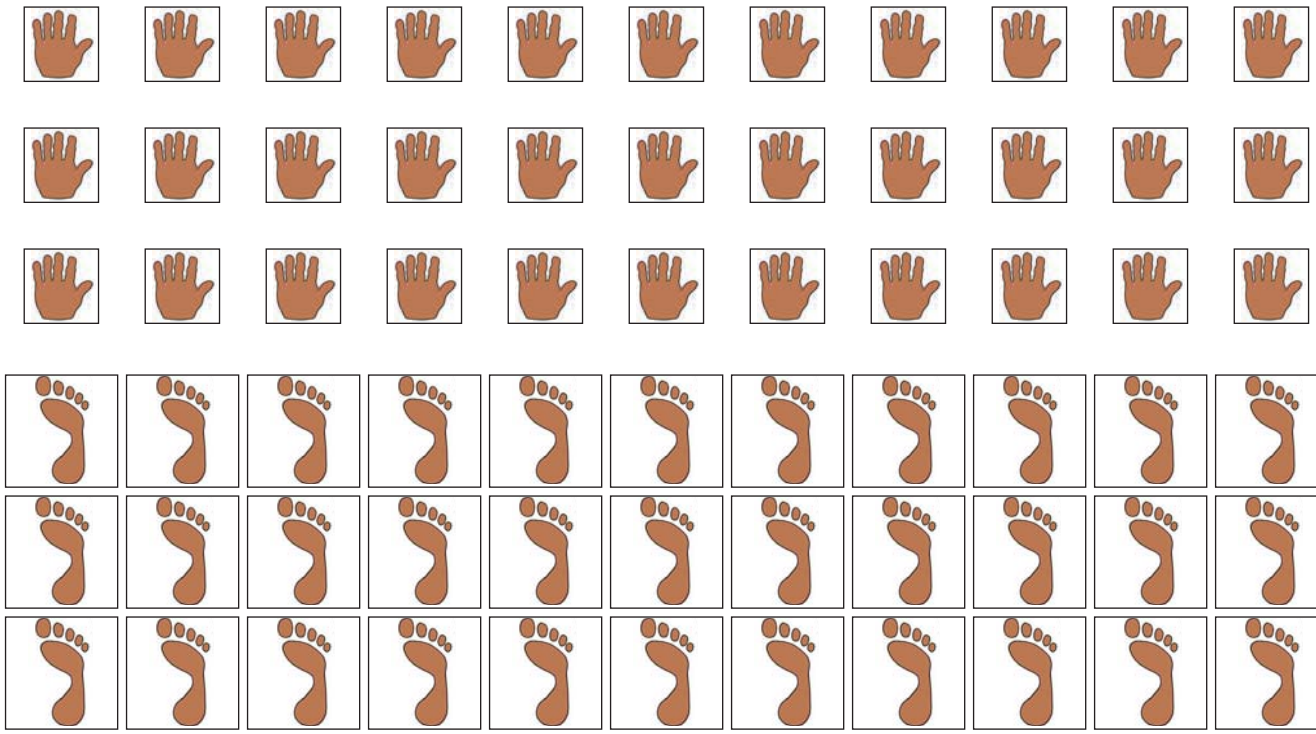

Lishadi lekusebentela 13

ekuseni kakhulu	imini yatsambama	intsambama
busuku	ekhatsi nebusuku	ekuseni nasemva kwemadina

Lokujutjiwe 2

Lishadi lekusebentela 22

Imicimbi yemlandvo

Lilanga lemalungelo ebantfu	Lilanga lekucolelana	Lilanga lebasebenti
Lilanga lebantfu labasha	Lilanga lemagugu	Lilanga labomake lavelonkhe
	Lilanga lenkhululeko	

Timphawu taletinkholo



Bhahayi	BuJuda	BuBhuda	BuMozilemu	Bukhrestu	Indzabuko yesiNtfu	BuHindu