

UNksk. Angie Motshekga, uMphathiswa wemfundo esisiSeko



UMnu. Enver Surty uSekela Mphathiswa wemfundo esisiSeko

Ezi ncwadi zilungiselelwe abantwana baseMzantsi Afrika phantsi kwephiko loMphathiswa weMfundo esisiSeko uNksk. Angie Motshekga kunye noSekela Mphathiswa weMfundo esisiSeko uMnu. Enver Surty.

Ezi ncwadi zokusebenzela, iRainbow Workbooks, lelinye lamalinge ongenelelo eSebe leMfundo esisiSeko ajolise ekuphuculeni umgangatho wabafundi beloMzantsi Afrika abakumabanga amathandathu okuqala. Njengomnye wemiba ephambili yoMkhomba-ndlela kaRhulumente, eli phulo libe nempumelelo ngenxa yenkxaso-mali evela kuVimba weSizwe. Oku kuye kwenza ukuba iSebe likwazi ukuvelisa ezi ncwadi, zifumaneke kuzo zonke iilwimi ezisemthethweni ngexabiso eliphantsi.

Sinethemba lokuba ootitshala baya kuzifumana ezi ncwadi zokusebenzela ziluncedo kakhulu kwimfundo yemihla ngemihla, nasekuqinisekiseni ukuba abafundi bayifikelela yonke ikharityhulam. Ukuqinisekisa ukuba utitshala uyakhokelwa kuyo yonke imisetyenzana, sisebenzise izalathisi ezibonisa oko kufanele ukwenziwa ngumfundi.

Sinethemba lokwenene lokuba abantwana baya kukonwabela ukusebenza kwezi ncwadi ekukhuleni nasekufundeni kwabo, kwanokuba nawe titshala uya kwabelana nabo kolu yolo.

Sinqwenela ukuba nibe nempumelelo ekusebenziseni ezi ncwadi.



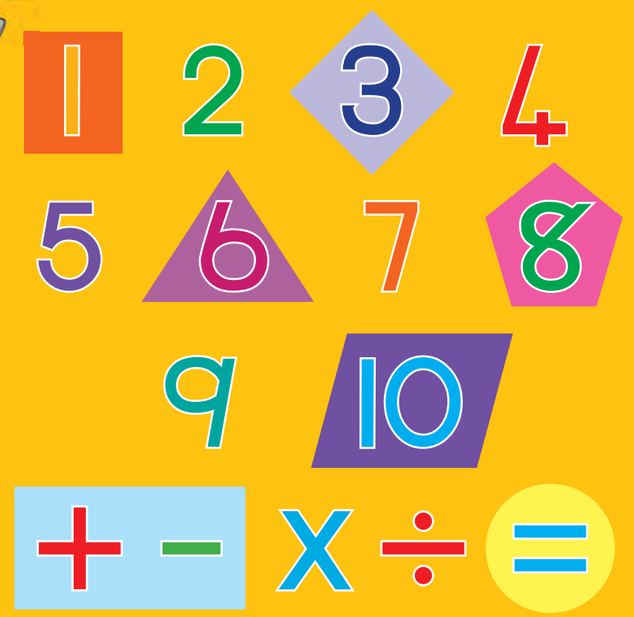

Rainbow WORKBOOKS

MATHEMATICS IN XHOSA
GRADE 2 – BOOK 1
TERMS 1 & 2
ISBN 978-1-920458-95-9

THIS BOOK MAY NOT BE SOLD.

IMATHEMATIKA–NGESIXHOSA – Ibanga lesi-2 Incwadi yoku-1

ISBN 978-1-920458-95-9



Ibanga lesi-2

IMATHEMATIKA NGESIXHOSA

Incwadi yoku-1

Ikota 1 & 2

Igama:

Iklasi:

basic education
Department:
Basic Education
REPUBLIC OF SOUTH AFRICA

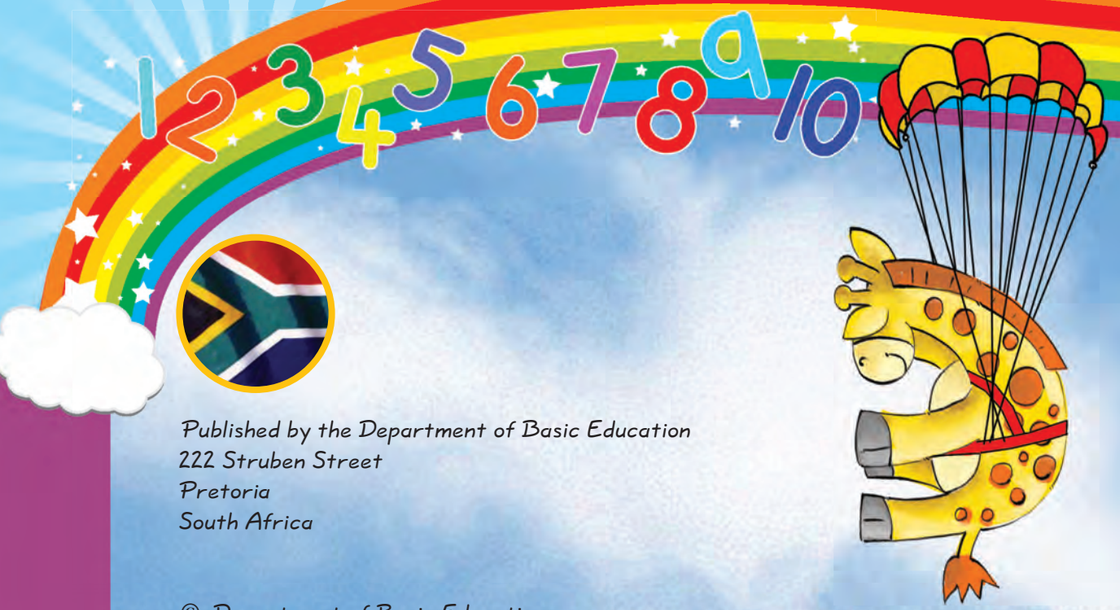

Published by the Department of Basic Education
222 Struben Street
Pretoria
South Africa

© Department of Basic Education
Third edition 2013

ISBN 978-1-920458-95-9

The Department of Basic Education has made every effort to trace copyright holders but if any have been inadvertently overlooked, the Department will be pleased to make the necessary arrangements at the first opportunity.

This book may not be sold.



basic education
Department:
Basic Education
REPUBLIC OF SOUTH AFRICA

1 – 100

1	2	3	4	5	6	7	8	9	10
11	12	13	14	15	16	17	18	19	20
21	22	23	24	25	26	27	28	29	30
31	32	33	34	35	36	37	38	39	40
41	42	43	44	45	46	47	48	49	50
51	52	53	54	55	56	57	58	59	60
61	62	63	64	65	66	67	68	69	70
71	72	73	74	75	76	77	78	79	80
81	82	83	84	85	86	87	88	89	90
91	92	93	94	95	96	97	98	99	100

1 2 3 4 5 6 7 8 9 10 11 12 13 14 15 16 17 18 19 20 21 22 23 24 25 26 27 28 29 30 31 32 33 34 35 36 37 38 39

Ibanga lesi-2

Rainbow WORKBOOKS

Imathematika

ngesiXHOSA

Le ncwadi yeka-:



ISIXHOSA

Incwadi yoku-1

1



Umhla:

Mna nosapho lwam





Bhala iimpendulo zale mibuzo imalunga nawe nosapho lwakho.

Igama lam ngu _____.

Ndineminyaka e _____ ubudala.

Bendineminyaka e _____ kwiminyaka emibini edlulileyo.

Ndiza kuba neminyaka e _____ kunyaka ozayo.

Ndihlala e _____.

Ngubani oyena mdala kowenu? _____

Bhala iminyaka yakhe _____.

Ngubani oyena mncinane kowenu? _____

Bhala iminyaka yakhe. _____

Umhla wanamhlanje _____.



1 2 3 4 5 6 7 8 9 10





Zoba umfanekiso wosapho lwakho.



1 2 3 4 5 6 7 8 9

Teacher:

Sign:

Date:



11 12 13 14 15 16 17 18 19 20

Umhla: _____

Ukubala



Zalisa izikhewu.



amehlo

amachaphaza

iipetshi



amehlo

amachaphaza

iipetshi





amehlo

amachaphaza

iipetshi



amehlo

amachaphaza

iipetshi



Yahlula amachaphaza neepetshi ngokulinganayo.









11 12 13 14 15 16 17 18 19 20

Teacher:

Sign:

Date:

3

Umhla:



Amanani



Funda iisimboli zamanani namagama asebhodini.

1	73	59	Ithoba	Ishumi elinanye
66	35		Ishumi elinesine	
				Thandathu
42	97	Ne	Ishumi elinesixhenxe	
24	32	Ishumi elinethoba		Ishumi



Bhala inani lamaso aphakathi kwibhloko nganye.

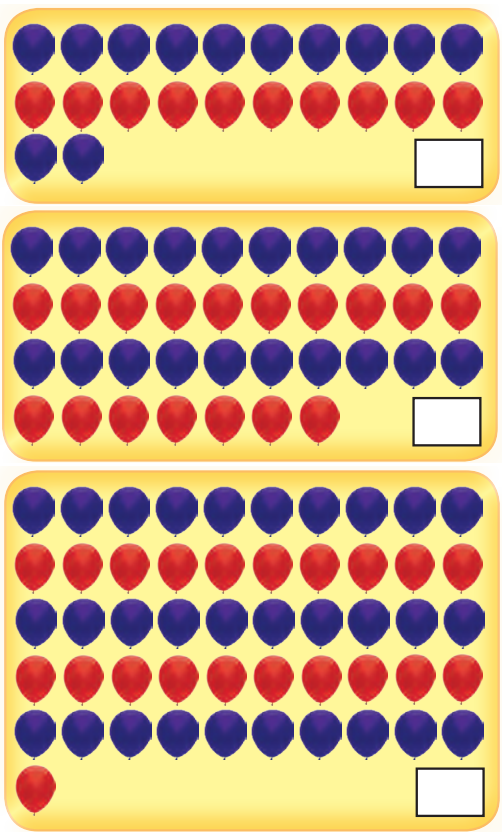



1 2 3 4 5 6 7 8 9 10





Bhala la manani alandelayo ngamazwi.



6 _____ 12 _____

4 _____ 17 _____

8 _____ 14 _____

1 _____ 22 _____

2 _____ 18 _____

5 _____ 11 _____

0 _____ 20 _____

10 _____ 15 _____

3 _____ 13 _____

9 _____ 16 _____



37 38 39 40 41 42 43 44

89 90 91 92 93 94 95 96

Teacher:

Sign:

Date:



11 12 13 14 15 16 17 18 19 20



Umhla:

Amanani





Zoba u-s koonombini uze uzobe u-1 kwiminqakathi.

Unombini

Iminqakathi

1	2	3	4	5	6	7	8	9	10
11	12	13	14	15	16	17	18	19	20



Fakela inombolo kwezi zindlu.







Bala le mibala mibini yamaso.

Bhala impendulo elinani:

Singayibhala ngolu hlobo:

10	2	=	12
10	3	=	
10	5	=	
10	8	=	
10	9	=	

10	+	2	=	12
	+		=	
	+		=	
	+		=	
	+		=	

Ithini impendulo?

10 + 1 =	10 + 9 =	10 + 6 =
10 + 8 =	10 + 2 =	10 + 3 =
10 + 5 =	10 + 4 =	10 + 7 =

1 3 5 7 9 11 13 15 17 19

2 4 6 8 10 12 14 16 18 20

Teacher:

Sign:

Date:

11 12 13 14 15 16 17 18 19 20

5

Umhla: _____

Ukudibanisa nokuthabatha





Dibanisa uthabathe.



9 + 8 = 17



18 – 8 = ☐



☐ + ☐ = ☐



☐ + ☐ = ☐



☐ + ☐ = ☐



Bala.

6 + 5 = ☐	8 + 9 = ☐	11 + 3 = ☐	12 – 5 = ☐
8 + 7 = ☐	3 + 8 = ☐	9 – 5 = ☐	16 – 9 = ☐
6 + 4 = ☐	8 + 4 = ☐	8 – 4 = ☐	6 – 4 = ☐

1 2 3 4 5 6 7 8 9 10



3 Dibanisa.

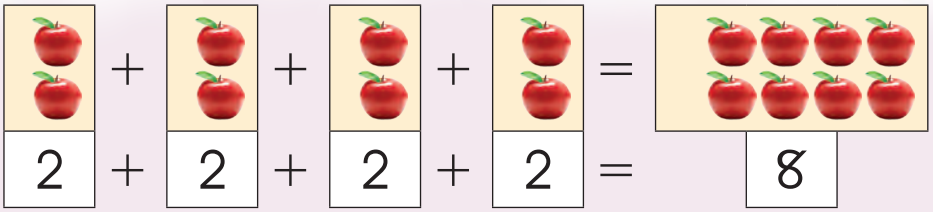

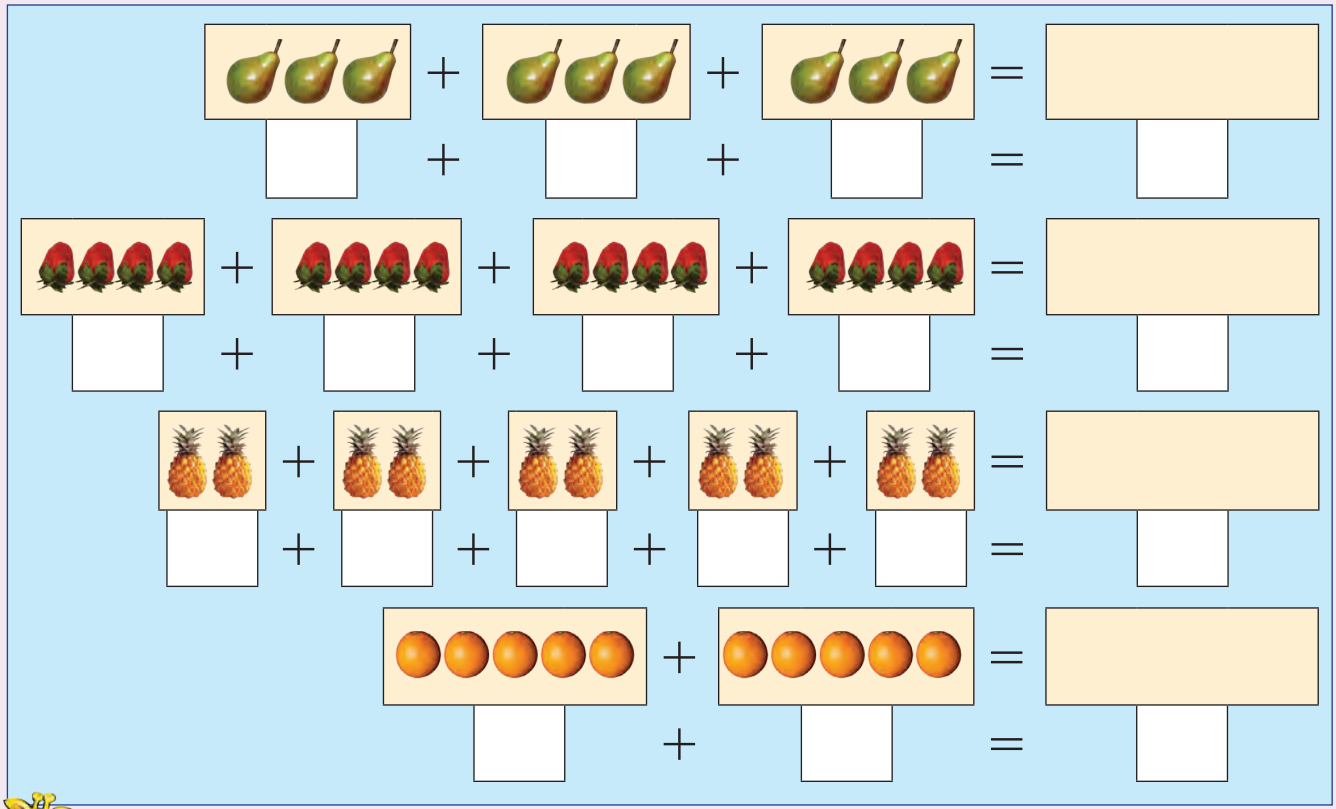

4 Bala.

2 + 2 + 2 = ☐	1 + 1 + 1 + 1 + 1 + 1 = ☐	2 + 2 + 2 + 2 = ☐
4 + 4 = ☐	3 + 3 + 3 + 3 = ☐	4 + 4 + 4 + 4 = ☐
5 + 5 + 5 = ☐	5 + 5 = ☐	1 + 1 + 1 = ☐

2 + 2 + 2 + 2 + 2 + 2

Teacher:
Sign:
Date:



Umhla: _____

Ukohlula nemali





Yaba iziqhamo ezingezantsi.











Gqibezela.








isenti e-1					









Fakela umbala kwiingqekembe zemali ezichanekileyo othi xa uzidibanisile zikunike impendulo efanayo.



10c	10c	5c	2c	1c	2c



5c	2c	2c	1c	2c	2c



R2	R2	R1	R1	R1



= R5 R2 R1 R5 R1 R2



= R2 R2 R5 R5 R2 R1 R5



R1 1c R5 5c R10

Teacher:
Sign:
Date:



11 12 13 14 15 16 17 18 19 20

7

Umhla:

Iipatheni

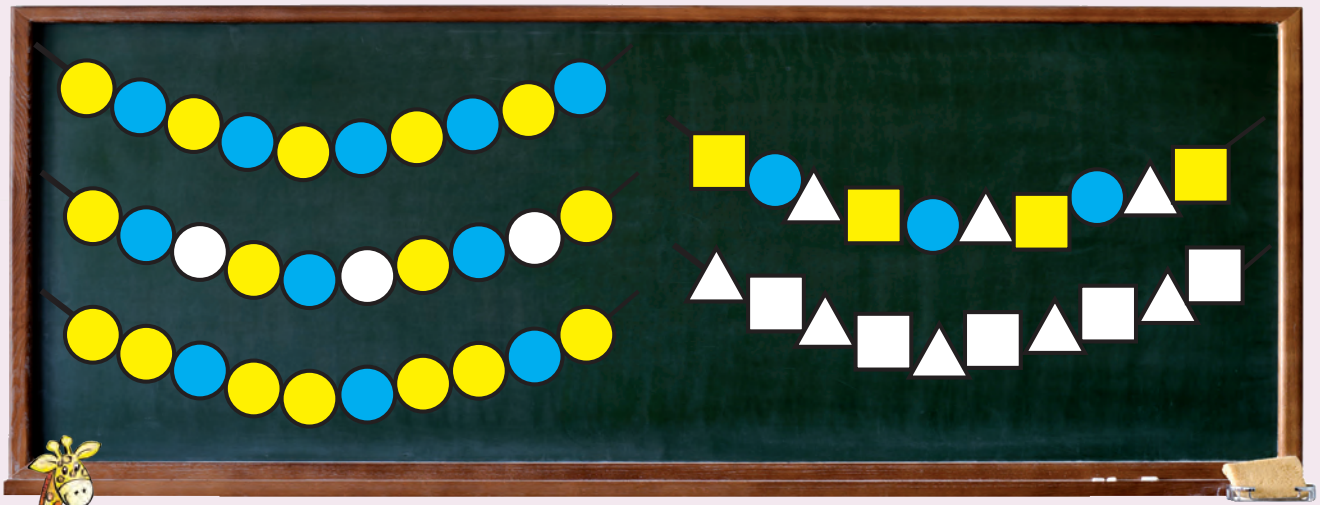

Kopa iipatheni ezisebhodini.

Yandisa iipatheni.

1 2 3 4 5 6 7 8 9 10





Fakela imibala kumaso xa ubala ngezibini.

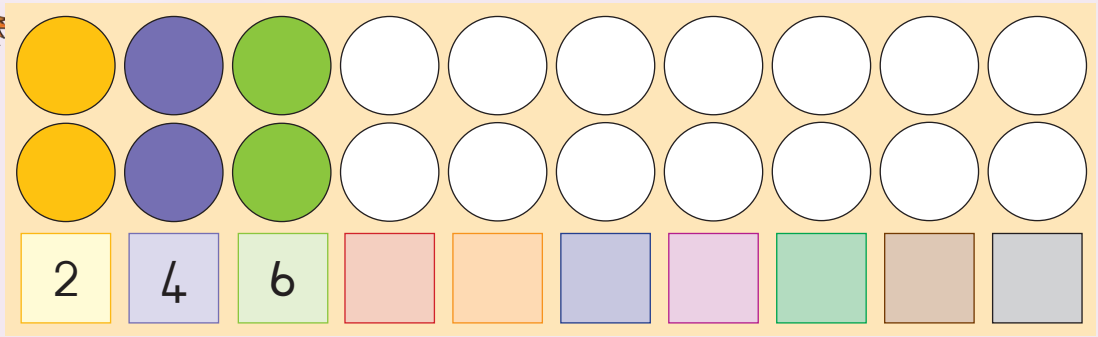



Fakela imibala kwiintyatyambo xa ubala ngezihlanu.

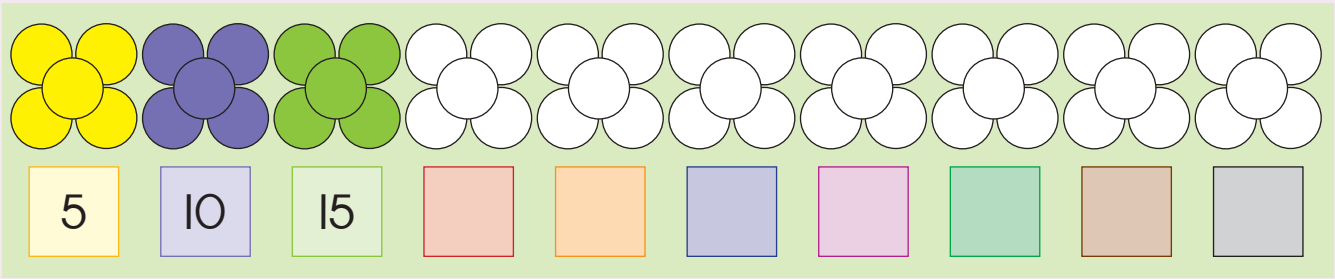



Fakela imibala kumaso xa ubala ngamashumi.

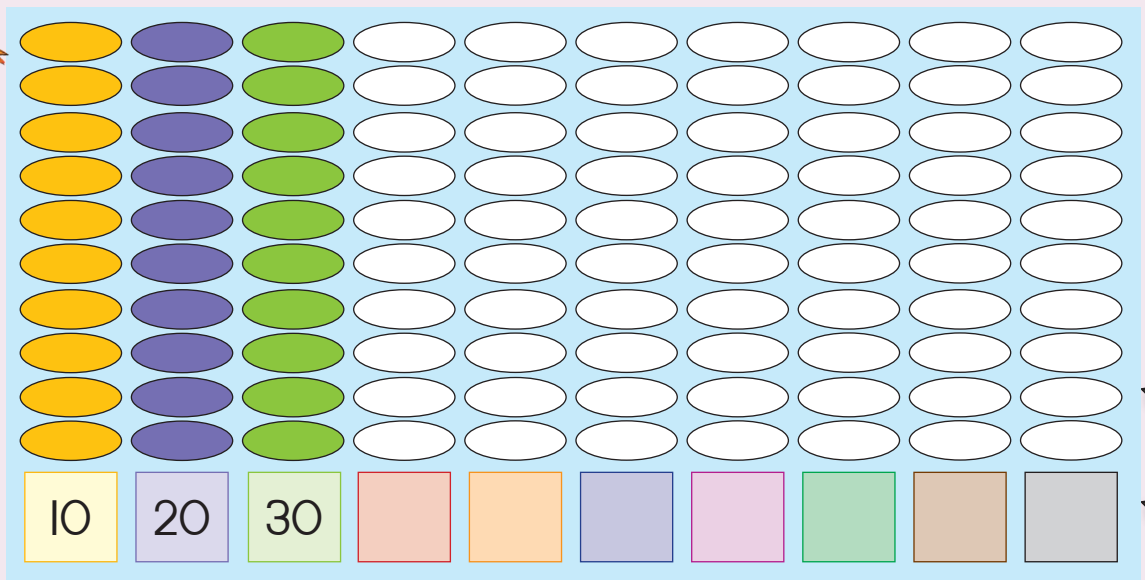



OOOOOOOOOO

Teacher:
Sign:
Date:



11 12 13 14 15 16 17 18 19 20

Umhla: _____

Imizobo



U faka umbala obhulowu kwirekthengile, obomvu kwizangqa, otyheli koonxantathu.

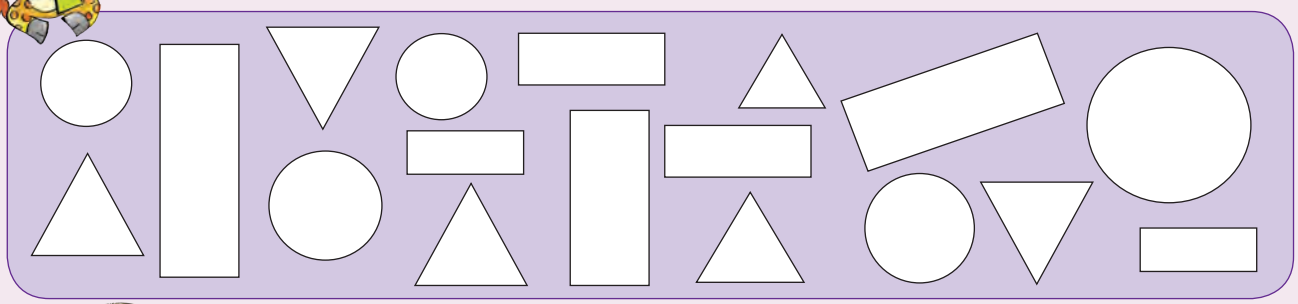

Faka umbala obomvu kuzo zonke izangqa ezikhulu, obhulowu kwirekthengile, otyheli koonxantathu abancinci.

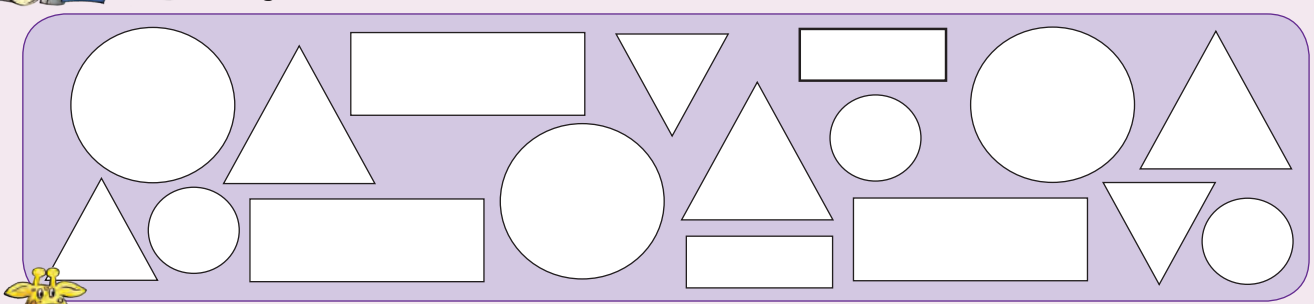

Faka umbala kwimpendulo echanekileyo.



ngqo | ngqukuva



ngqo | ngqukuva



ngqo | ngqukuva





Zoba elinye icala lebhabhathane.





Teacher:

Sign:

Date:



11 12 13 14 15 16 17 18 19 20

Umhla: _____

Iibhola neebhokisi





Bhala isangqa esibhulowu kwiibhokisi uze ubhale isangqa esibomvu kwiibhola.



Faka umbala kwimpendulo echanekileyo.



Ibhokisi | iyatyibilika | iyaqengqeleka



Ibhola | iyatyibilika | iyaqengqeleka

Faka umbala kwimpendulo echanekileyo.



Isiphelo esisicaba

Isiphelo esithe ngqo



Isiphelo esisicaba

Isiphelo esithe ngqo



Isiphelo esisicaba

Isiphelo esithe ngqo



Isiphelo esisicaba

Isiphelo esithe ngqo



Isiphelo esisicaba

Isiphelo esithe ngqo



Isiphelo esisicaba

Isiphelo esithe ngqo



Isiphelo esisicaba

Isiphelo esithe ngqo



Isiphelo esisicaba

Isiphelo esithe ngqo

Yitsho ukuba ingaba ibhola ingemva, ingaphambili, isecaleni, okanye iphezu kwebhokisi na.



Inga-phambili

Isecaleni

Inga-phezulu

Ingasemva



Inga-phambili

Isecaleni

Inga-phezulu

Ingasemva



Inga-phambili

Isecaleni

Inga-phezulu

Ingasemva



Inga-phambili

Isecaleni

Inga-phezulu

Ingasemva



Ibhola Ibhokisi

Teacher:

Sign:

Date:

Umhla: _____

Ubude





Yeyiphi itreyini emfutshane okanye ende?





imfutshane | inde



imfutshane | inde



Sesiphi isakhiwo eside okanye esifutshane?



side

sifutshane



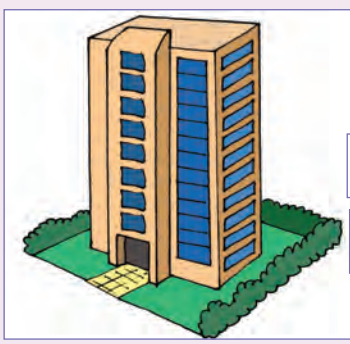

side

sifutshane





Ngowuphi umntu omfutshane okanye omde?



mfutshane	mfutshane
mde	mde



Sebenzisa umsiko I wesandla. Zizandla ezingaphi ubude bale rekthengile?
Sebenzisa umsiko I wonyawo. Ziinyawo ezingaphi ubude bale rekthengile?







Ngoku linganisa ukuphakama kwerekthengile ngezandla nangeenyawo.







Teacher:
Sign:
Date:



Umhla:

Ubunzima





Yitsho ukuba le nto inzima okanye ikhaphu-khaphu kunekhilogram e-I.



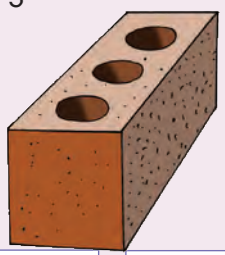

inzima	ikhaphu-khaphu	inzima	ikhaphu-khaphu



Zoba isangqa kweyona nto inzima.













Ingaba ubunzima bale nto bungaphezulu okanye bungaphantsi kwekhilogram enye na?



inzima | ikhaphu-khaphu



inzima | ikhaphu-khaphu



inzima | ikhaphu-khaphu



inzima | ikhaphu-khaphu



Inzima Ikhapu-khaphu

Teacher:
Sign:
Date:



11 12 13 14 15 16 17 18 19 20

Umhla:

Umthamo



Faka umbala kwimpendulo echanekileyo.



izele	ayinanto	isiqingatha



izele	ayinanto	isiqingatha



izele	ayinanto	isiqingatha



izele	ayinanto	isiqingatha



izele	ayinanto	isiqingatha

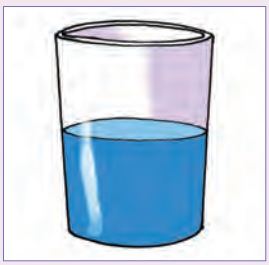

izele	ayinanto	isiqingatha





Umlinganiselo omnye uzalisa isiphawuli sokuqala kule jagi.
Ingaba yimilinganiselo emingaphi enokuzalisa le jagi?





Mingaphi imilinganiselo egalelwe kule jagi?



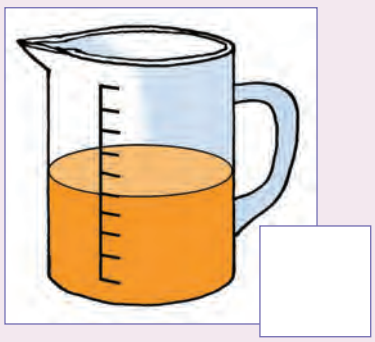





Ijagi engasekhohlo ithatha amanzi angangelitha enye. Yeyiphi ijagi ethatha ngokulingana nayo, iyeyiphi ethatha isiselo seziqhamo esingaphantsi?





iyafana	ingaphantsi



iyafana	ingaphantsi



Izele Ayinanto

Teacher:
Sign:
Date:



11 12 13 14 15 16 17 18 19 20



Umhla: _____

Ixesha

Yiya kumsiko woku-1. Sika amagama uze uwancamathisele ngezantsi kwemifanekiso.



Gqibezela ezi zivakalisi.

Ndi _____ kwangentseni/ekuseni.

Ndi _____ ekuseni.

Ndi _____ emva kwemini

Ndi _____ yonke imihla.

Ndi _____ ebusuku yonke imihla.

1 2 3 4 5 6 7 8 9 10



Izolo | Namhlanje | Ngomso





Phendula le mibuzo.

Wenza ntoni umntwana namhlanje? _____

Ebesenza ntoni umntwana izolo? _____

Uza kwenza ntoni ngomso umntwana? _____



Zoba umfanekiso wakho.

Izolo	Namhlanje	Ngomso



Izolo Izolo

Teacher:
Sign:
Date:



Umhla: _____

Ikhalenda yomhla wokuzalwa





Dwelisa iinyanga.

Janyuwari
Sipho
Maryke
Annie

Febhuwari
Jeffrey
Simon

Matshi
Sam
Juan

Epreli
Betty
Liezel

Meyi
Bongi
Ricco
George

Juni
Mpho

Julayi
Palesa
Lisa
Kayla

Agasti
Mbali
Brenda
Mary

Septemba
Themba

Okthobha
Karin
Jaco

Novemba
Gugu
Dian

Disemba
Lebo
Richard
Denise

1 2 3 4 5 6 7 8 9 10





Bhala igama lomntwana ngamnye kwikhalenda.

Janyuwari	Febhuwari	Matshi
Epreli	Meyi	Juni
Julayi	Agasti	Septemba
Okthobha	Novemba	Disemba



Usuku lwam lokuzalwa

Teacher:
Sign:
Date:

11 12 13 14 15 16 17 18 19 20



Umhla: _____

Ukuqokelela nokuhlela





Qokelela uze uhlele iibhola uze uzizobele kwibhokisi echanekileyo.

iibhola eziluhlaza	iibhola ezibomvu	iibhola ezibhulowu	iibhola ezityheli



Qokelela iintyatyambo uze uzihlele.

iintyatyambo ezityheli	iintyatyambo ezibomvu	iintyatyambo ezipepuli	iintyatyambo ezipinki	iintyatyambo eziorenji

1 2 3 4 5 6 7 8 9 10



Hlela izinto. Zenzele imifanekiso engeyakho.



izinto ezikhaphu-khaphu

izinto ezinzima



iibhola ezincinci

iibhola ezinkulu

iibhokisi ezincinci

iibhokisi ezinkulu

Teacher:

Sign:

Date:

11 12 13 14 15 16 17 18 19 20

Umhla:

Ukufunda nokutolika



Umfanekiso wam





Hlela iikhrayoni. Zoba umfanekiso ngazo.





Hlela iikhrayoni. Zoba umfanekiso ngazo.





Hlela amafu neminyama. Yizobe.





Phendula imibuzo.

		
oonxantathu	iirekthengile	izangqa

Bangaphi oonxantathu abakhoyo? _____

Zingaphi iirekthengile ezikhoyo? _____

Zingaphi izangqa ezikhoyo? _____

Ingaba ngoonxantathu abaninzi okanye ziirekthengile? _____

Ingaba zizangqa ezininzi okanye ngoonxantathu? _____

Ingaba zizangqa ezininzi okanye ziirekthengile? _____

		
ayinanto	isiqingatha	izele

Zingaphi iijagi ezingenanto? _____

Zingaphi iijagi ezizele kangangesiqingatha? _____

Zingaphi iijagi ezizeleyo? _____



O I A I O I A I O I A I O I A I O

Teacher:

Sign:

Date:

11 12 13 14 15 16 17 18 19 20

Umhla: _____

Phambi, emva nangaphakathi

Chaza amanani ngokuthi usebenzise la magama 'phambi', 'phakathi' no 'emva'.

1	2	3	4	5	6	7	8	9	10	11	12	13	14	15	16	17	18	19	20	21	22	23	24	25

umz. Ibhola nganye ebomvu iphakathi kweebhola ezibhulowu ezimbini.





Bhala inani elichanekileyo phakathi kwisikwere.

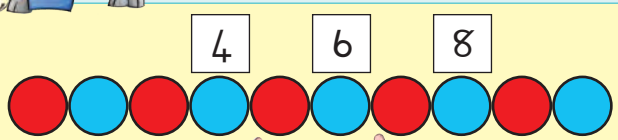

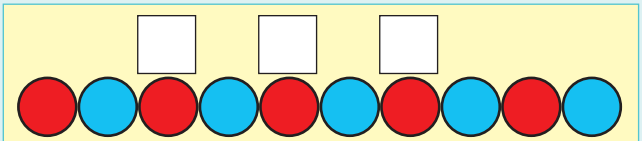

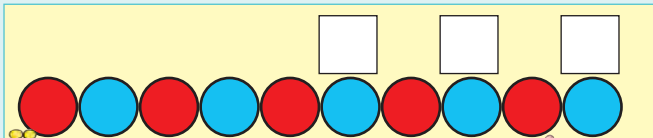

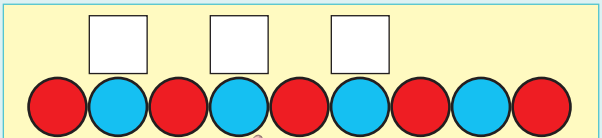

Fakela amanani angekhoyo.

	2			5	
	12			15	
13			16		

10			13		
	17			20	
20					25

1	2	3	4	5	6	7	8	9	10	11	12	13	14	15	16	17	18	19	20	21	22	23	24	25

Leliphi inani eliphambi kwesi-8? _____

Leliphi inani elisemva kwe-16? _____

Ngawaphi amanani aphakathi kwesi-8 ne-12? _____



Faka umbala obhulowu kumanani aphakathi kwe-14 ne-17. Faka umbala obomvu kwinani eliza phambi kwe-14. Faka umbala otyheli kwinani eliza emva kwe-17

11	12	13	14	15	16	17	18	19	20

11 12 13 14 15 16 17 18 19 20 21 22 23 24 25 26 27 28 29 30

Bhala phantsi onke amanani akumaso atyheli.
Sithini xa siwabiza la manani abhalwe kumaso atyheli?

_____

Bhala phantsi onke amanani akumaso apinki.
Sithini xa siwabiza amanani abhalwe kumaso apinki?

_____

1 2 3 4 5 6 7 8 9 10 11 12 13 14 15 16 17 18 19 20



Yahlulela abantwana abanxibe tyheli amaso atyheli.

Ufumana amaso amangaphi umntwana emnye?_____. Akhona amaso aseleyo?_____

Yahlulela abantwana abanxibe pinki amaso apinki.

Ufumana amaso amangaphi umntwana emnye?_____. Akhona amaso aseleyo?_____

Phendula le mibuzo ilandelayo.

Ngawaphi amanani angoonombini aza kwangoko emva kwe-12? _____
Ngawaphi amanani ayiminqakathi aza kwangoko emva kwe-14?_____
Ngawaphi amanani ayiminqakathi aphakathi kwe-10 ne-16? _____
Bhala phantsi oonombini abaphakathi kwesi-8 ne-18?_____

Teacher:
Sign:
Date:



Umhla:

Amanani 1–30

Zingaphi iincwadi ozibalayo?
Zingaphi iibhotile zepeyinti ozibalayo?



1 Mangaphi ewonke la maso?

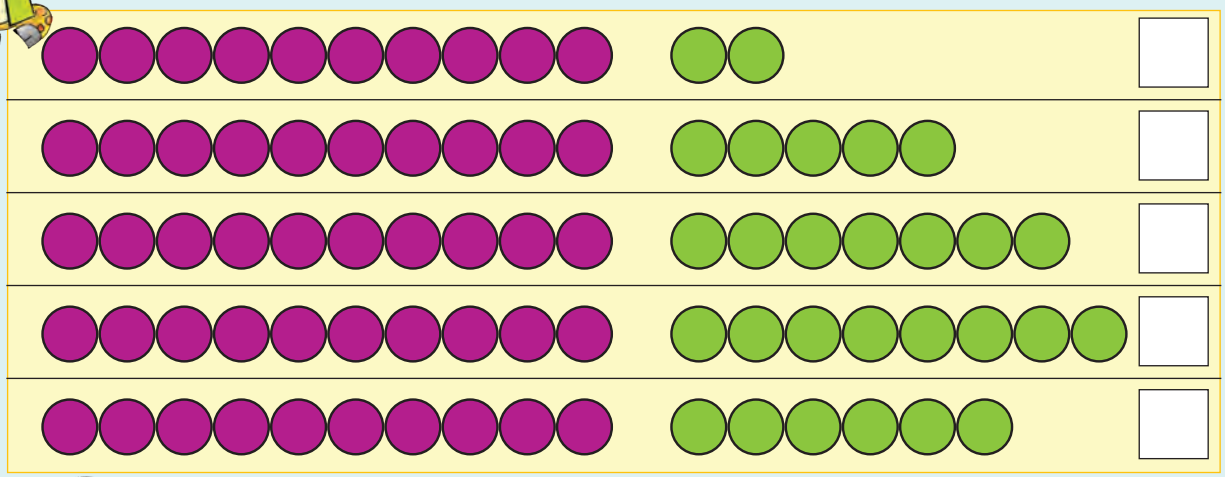

2 Zingaphi zizonke ezi ncwadi?



3 Fakela amanani angekhoyo.

14	12	15	17	19	13	26	28	21	30
10 4	2	10	7	10					

1 2 3 4 5 6 7 8 9 10



Jonga kumzekelo wokuqala uze ugqibezele okuseleyo.

18	=	1	ishumi elinye	+	8	nemivo esi-	okanye	18	=	10	+	8
15	=		ishumi elinye	+		nemivo emi-	okanye		=		+	
19	=		ishumi elinye	+		nemivo eli-	okanye		=		+	
22	=		amashumi amabini	+		nemivo emi-	okanye		=		+	
24	=		amashumi amabini	+		nemivo emi-	okanye		=		+	

Mangaphi ewonke la maso?

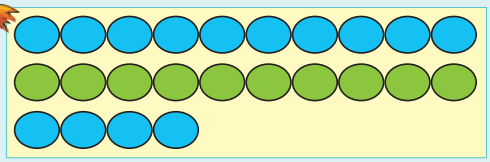

Inani

Singalibhala ngolu hlobo:

20 + ☐ = 24

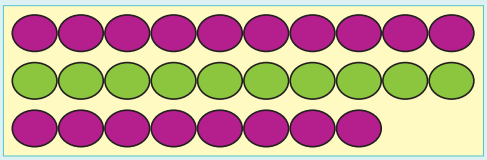

Inani

Singalibhala ngolu hlobo:

20 + ☐ = 28

Bhala amagama ala manani:

10		11	
12		13	
14		15	
16		17	
18		19	
20		21	
22		23	
24		25	

Jonga kumzekelo wokuqala uze ugqibezele okuseleyo.

25	=	2	amashumi	+	5	iiyunithi		22	=	2	amashumi	+	2	iiyunithi
13	=		ishumi	+		iiyunithi		21	=		amashumi	+		iyunithi
26	=		amashumi	+		iiyunithi		19	=		ishumi	+		iiyunithi

Teacher:
Sign:
Date:



Umhla: _____

Imigca-manani





Fakela la manani angekhoyo.

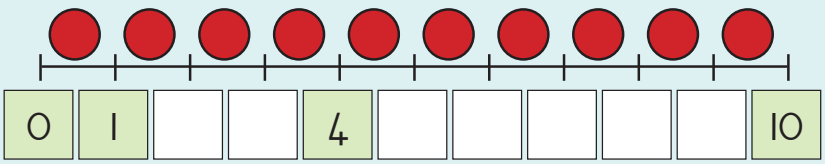

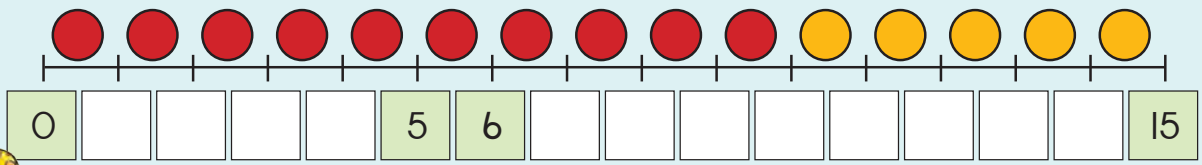



Utsibe waya kuma phi umvundla? Sebenzisa umgca-manani ukuncede ufumane iimpendulo.

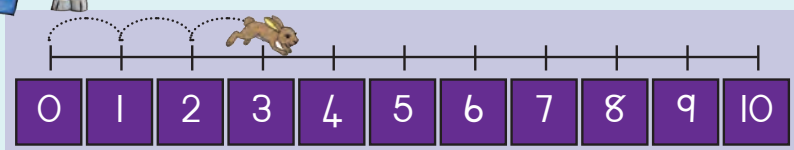

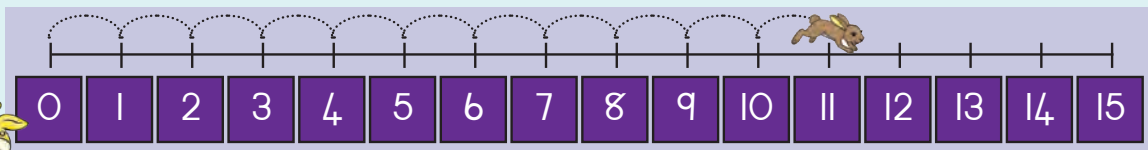



Itsibe yaya kuma phi impala? Sebenzisa umgca-manani ukuncede ufumane iimpendulo.

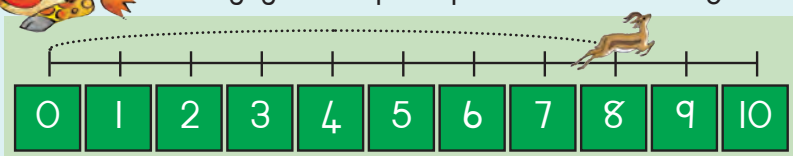

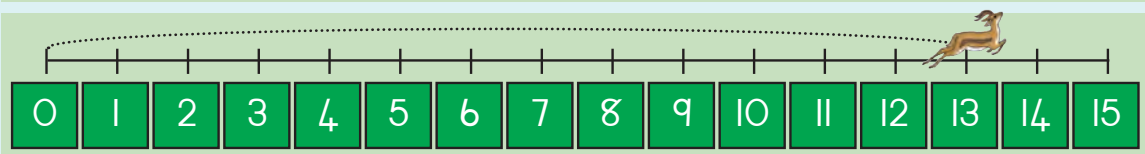



Gqibezela umgca-manani. Utsibe waya kuma phi umvundla?

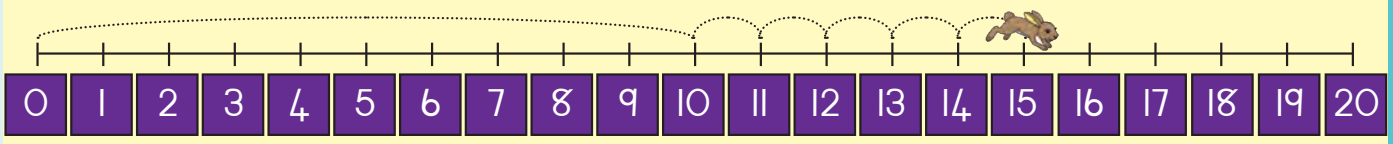

10 + 5 = ☐

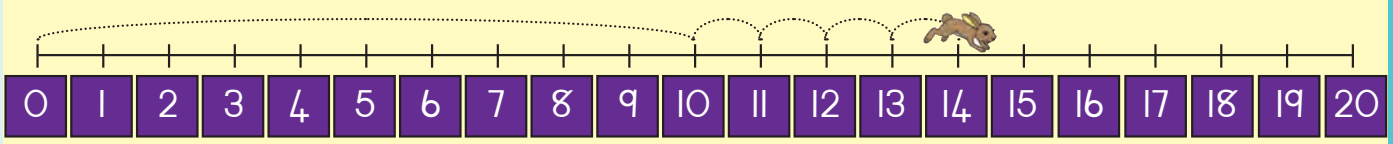

☐ + ☐ = ☐

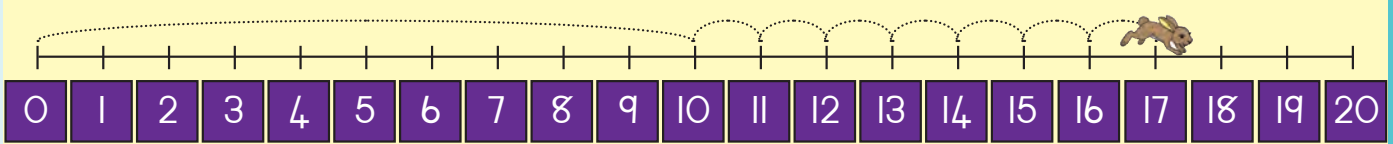

☐ + ☐ = ☐

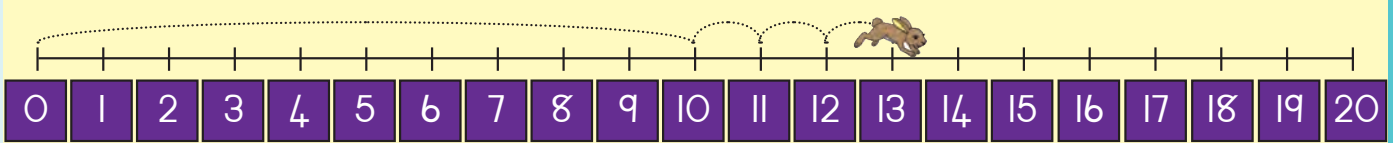

☐ + ☐ = ☐

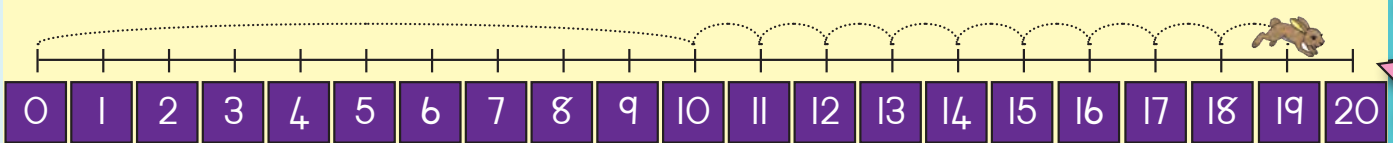

☐ + ☐ = ☐



Teacher:
Sign:
Date:



Umhla: _____

Eminye imigca manani





Ncedisa umvundla ukubala. Sebenzisa umgca-manani ukuncede ufumane iimpendulo.

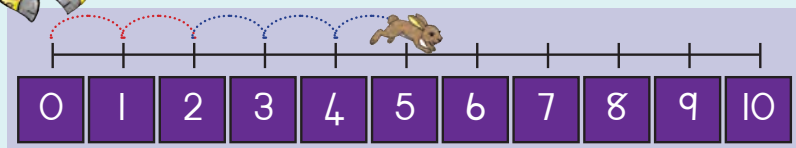

2 + 3 = 5

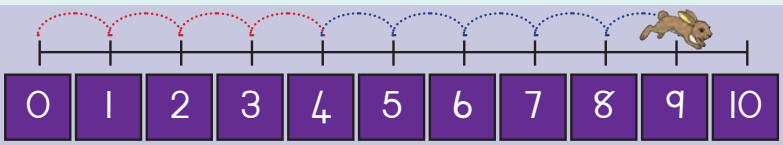

__ + __ = __



Ncedisa i-impala ukubala.
Sebenzisa umgca-manani ukuncede ufumane iimpendulo.

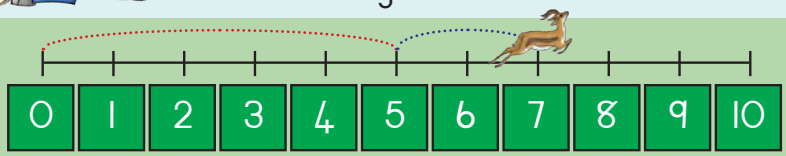

__ + __ = __

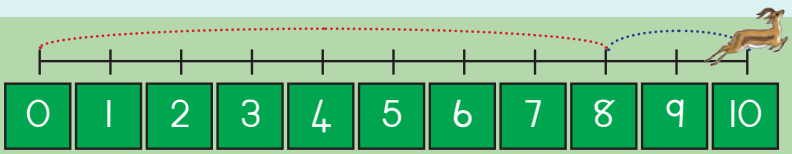

__ + __ = __





Ncedisa umvundla ukubala.

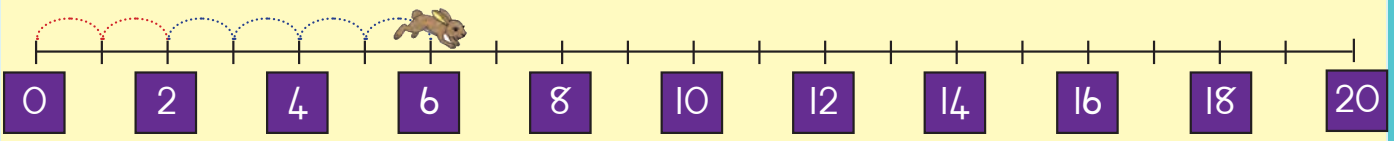

2 + 4 = 6

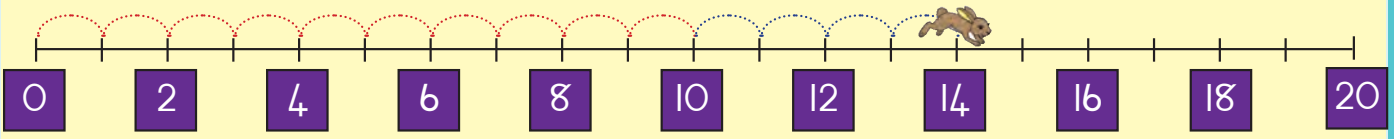

__ + __ = __



Ncedisa i-impala ukubala.

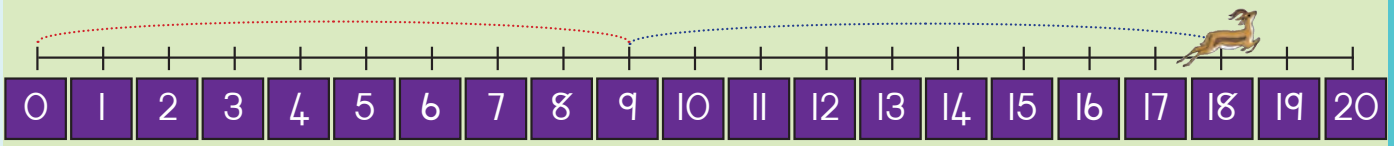

9 + 9 = __

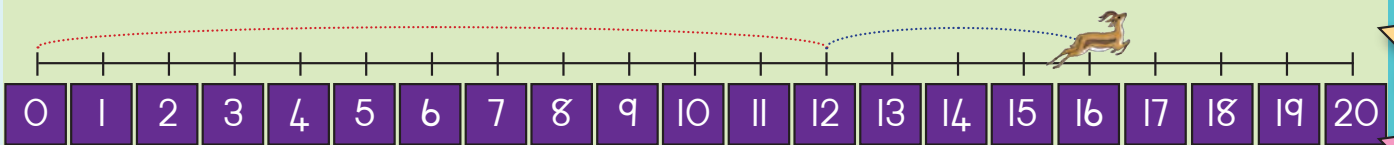

__ + __ = __



Teacher:

Sign:

Date:



Umhla: _____

Ukudibanisa nokuthabatha

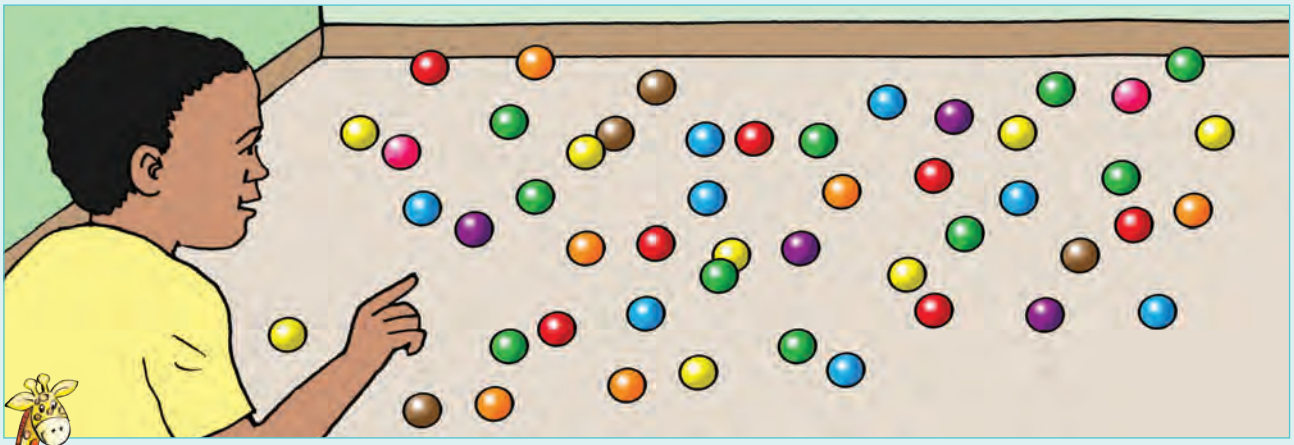



Bhala inani lamaso.

Mangaphi amaso abomvu akhoyo? ____

Mangaphi amaso abhulowu akhoyo? ____

Mangaphi amaso aluhlaza akhoyo? ____

Mangaphi amaso aorenji akhoyo? ____

Mangaphi amaso apepuli akhoyo? ____

Mangaphi amaso akhoyo ewonke? ____



Bhala inani lamaso kwiibhokisi ezichanekileyo uze uwadibanise.

bomvu	+	luhlaza	=	
tyheli	+	pinki	=	
orenji	+	bhulowu	=	
pepuli	+	luhlaza	=	
bhrawuni	+	tyheli	=	



Gqibezela iipatheni.





Sebenzisa amaso ukuzalisa kwibhokisi.

8	+	7	=	15
8	+ 2 +	5	=	
9	+	6	=	
9	+		=	

Tshatisa umfanekiso kunye nesibalo uze unike impendulo.

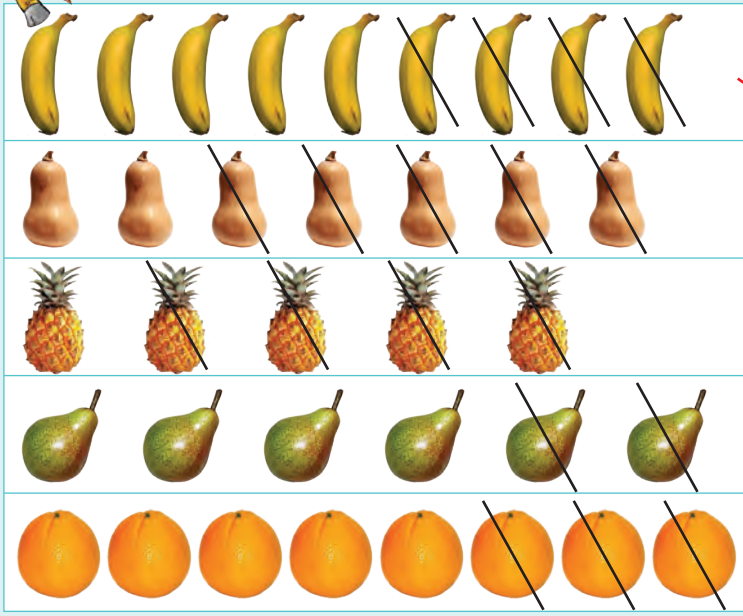

7 – 5 =	
9 – 4 =	
8 – 3 =	
5 – 4 =	
6 – 2 =	

Bhala impendulo yesi sibalo:

9 – 6 = 3	– =
– =	– =

Teacher:
Sign:
Date:

Umhla: _____

Iintsuku, iiveki kunye neenyanga

uMvulo
uLwesibini
uLwesithathu
uLwesine
uLwesihlanu
uMgqibelo
iCawe

Janyuwari	Febhuwari	Matshi
Epreli	Meyi	Juni
Julayi	Agasti	Septemba
Okthobha	Novemba	Disemba



1 Phendula le mibuzo ilandelayo imalunga neeveki.

Loluphi usuku oluza phambi kukaLwesithathu? _____

Loluphi usuku oluza emva kukaLwesithathu? _____

Loluphi usuku oluza emva koMgqibelo? _____

Loluphi usuku oluphakathi koMvulo noLwesithathu? _____

Ukuba uMvulo lusuku lokuqala, loo nto ithetha ukuba uLwesihlanu lusuku lwesingaphi? _____

Zeziphi iintsuku eziphakathi koLwesithathu noMgqibelo? _____

_____



2 Phendula le mibuzo ilandelayo imalunga neenyanga.

Yeyiphi inyanga eza phambi kukaEpreli? _____

Yeyiphi inyanga eza emva kukaJuni? _____

Yeyiphi inyanga ephakathi kuka-Agasti no-Okthobha? _____

Zeziphi iinyanga eziphakathi kukaJanyuwari kunye noJuni? _____

_____

Yeyiphi inyanga yokuqala enyakeni? _____

Yeyiphi inyanga yokugqibela enyakeni? _____



Iinkolo zaseMzantsi Afrika



Iziganeko zembali

Usuku lwamalungelo oluntu

Usuku lwenkululeko

Usuku lwabasebenzi

Usuku lolutsha

Usuku lukazwelonke lwamanina

Usuku lwezamafa

Usuku loxolelwaniso

Usuku lokuzalwa

Usuku lwam lokuzalwa





Umsiko 2: Sebenzisa imifanekiso oyisikileyo uze uyincamathisele kwiinyanga ezikwikhalenda. Khetha iintsuku zeenkolo zeenkonzo zibe ntathu zalapha eMzantsi Afrika, kunye nazo zonke iintsuku zeeholide zikawonke-wonke.

Janyuwari	Febhuwari	Matshi
Epreli	Meyi	Juni
Julayi	Agasti	Septemba
Okthobha	Novemba	Disemba



Teacher:

Sign:

Date:



Umhla: _____

Ukudibanisa

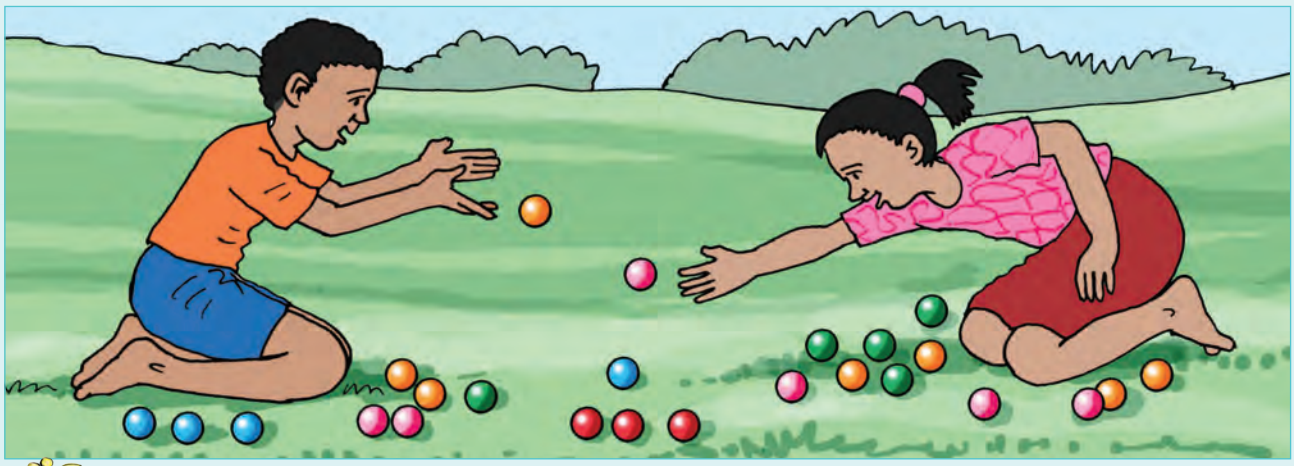



Jonga kumfanekiso uze ubale amabhastile.

bomvu	+	bhulowu	=	3	+	4	=	
luhlaza	+	bhulowu	=		+		=	
tyheli	+	bhulowu	=		+		=	
luhlaza	+	orenji	=		+		=	
bomvu	+	luhlaza	=		+		=	
orenji	+	bhulowu	=		+		=	



Ukudibanisa.

3 + 2 =	4 + 6 =	9 + 3 =
6 + 5 =	7 + 8 =	8 + 4 =
9 + 5 =	8 + 6 =	7 + 4 =
9 + 9 =	7 + 5 =	8 + 8 =
7 + 6 =	9 + 6 =	7 + 7 =



Bhala izibalo ezilandelayo:

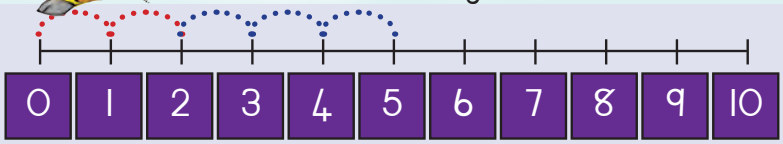

2 + 3 = 5

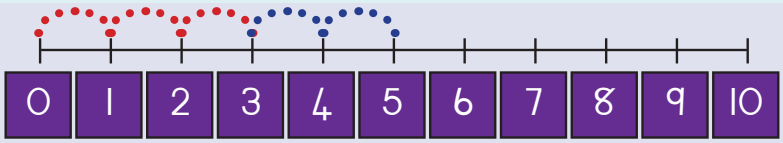

__ + __ = __



__ + __ = __



__ + __ = __

Yenza le milinganiselo ilingane. Sesikwenzele eyokuqala.

5 = 1 + 4



6 = 2 + __

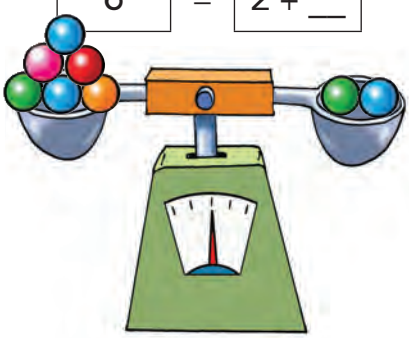

3 + __ = __



2 + 1 = 1 + __

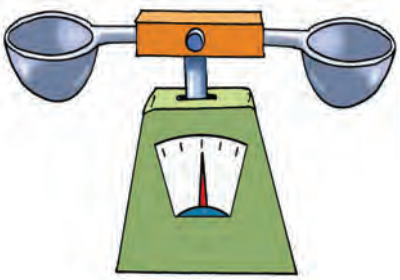

6 + 3 = 3 + __

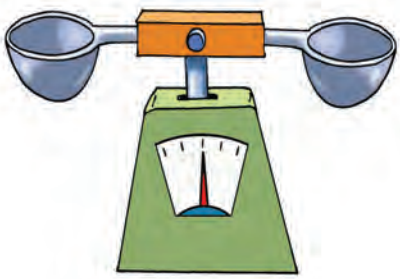

2 + __ = 8 + 2



Teacher:

Sign:

Date:

Umhla:

Ukuthabatha

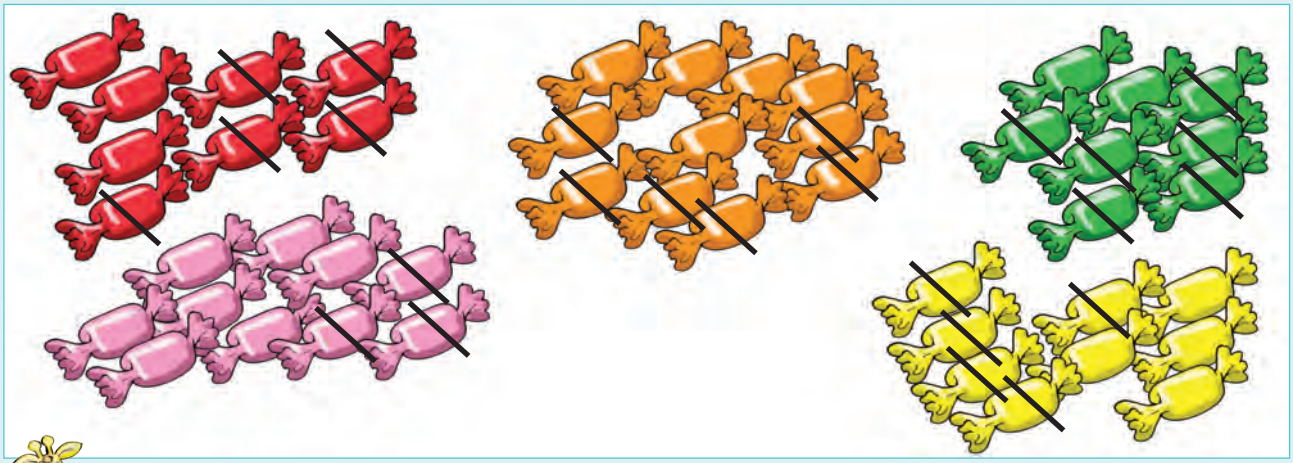



Jonga kumfanekiso uze ubale.

iilekese ezibomvu	=	8	–	5	=	3
iilekese eziluhlaza	=		–		=	
iilekese ezityheli	=		–		=	
iilekese eziorenji	=		–		=	
iilekese ezipinki	=		–		=	



Ukuthabatha.

5 – 3 =	10 – 6 =	12 – 3 =
11 – 5 =	15 – 7 =	12 – 4 =
14 – 9 =	14 – 8 =	11 – 4 =
18 – 9 =	12 – 5 =	16 – 8 =
13 – 7 =	15 – 6 =	14 – 7 =





Dibanisa.

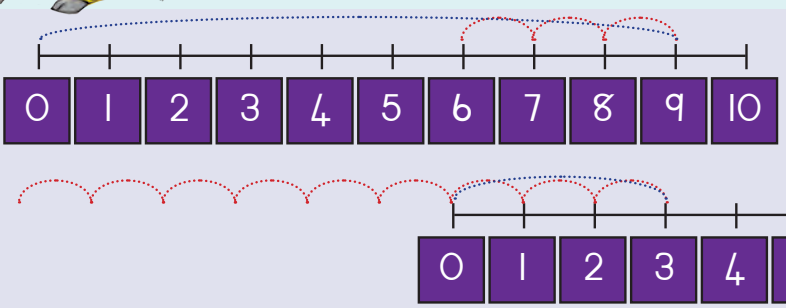

9 – 3

Ayilingani

3 – 9

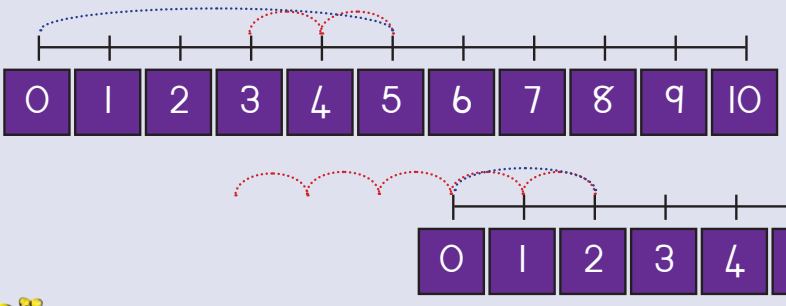

5 – 2

Ayilingani

2 – 5



Bala ezi zibalo:

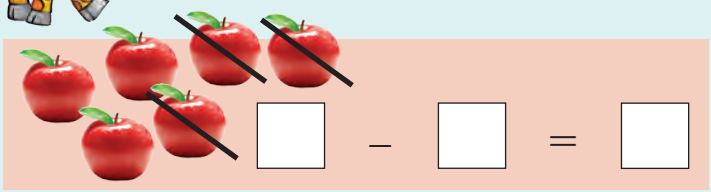

□ – □ = □





□ – □ = □



□ – □ = □

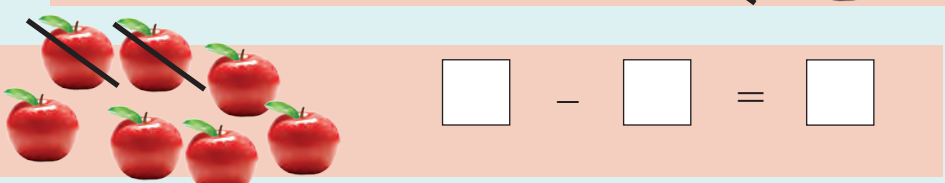

□ – □ = □

Teacher:

Sign:

Date:



11 12 13 14 15 16 17 18 19 20

Umhla: _____

Ukudibanisa (kusaqhutywa)

Thelekisa la makhasi.

2 + 10	8 + 10	7 + 10	5 + 10	3 + 10
7 + 10 = 17	10 + 2 = 12	10 + 5 = 15	3 + 10 = 13	10 + 8 = 18

Sebenzisa umgca-manani. Dibanisa la manani. Sesikwenzele eyokuqala.

0 1 2 3 4 5 6 7 8 9 10 11 12 13 14 15 16 17 18 19 20

10 + 4 = 14

0 1 2 3 4 5 6 7 8 9 10 11 12 13 14 15 16 17 18 19 20

___ + ___ = ___

0 1 2 3 4 5 6 7 8 9 10 11 12 13 14 15 16 17 18 19 20

___ + ___ = ___

0 1 2 3 4 5 6 7 8 9 10 11 12 13 14 15 16 17 18 19 20

___ + ___ = ___

1 2 3 4 5 6 7 8 9 10





Ukudibanisa.

10	+	3	=	13	10	+	2	=	
10	+	5	=		10	+	7	=	
10	+	1	=		10	+	6	=	
10	+	4	=		10	+	8	=	
10	+	9	=		10	+	3	=	



Ukudibanisa.

16 + 13

10		10		20			
6	+	3	=	9			
16	+	13	=	29			

14 + 12

10		10					
4	+	2	=				
	+		=				

17 + 11

10		10					
7	+	1	=				
	+		=				

15 + 13

10		10					
5	+	3	=				
	+		=				

16 + 12

10		10					
6	+	2	=				
	+		=				

18 + 12

10		10					
8	+	2	=				
	+		=				



ULisa unezixhobo zokubala ezili-9, uPeter abe nezisi-8.





Zingaphi zizonke?

Teacher:

Sign:

Date:



11 12 13 14 15 16 17 18 19 20

Umhla: _____

Imali

1 Kukho ntoni ebhankini yam?



2 Sika iingqekembe kumsiko-3 uze uzincamathisele apha.

50c	70c
90c	60c
40c	80c





Zingaphi iisenti.















Izibalo zamazwi.

USuzy unama-50c. Umama wakhe umnika ama-20c ngaphezulu. Unamalini ngoku uSuzy?

_____

Ndinama-90c. Ndithenge iilekese ngama-30c. Ndinamalini eshiyekileyo?

_____

Teacher:
Sign:
Date:



Umhla: _____

Imali eliphepha

1 Ndinamalini esipajini sam?

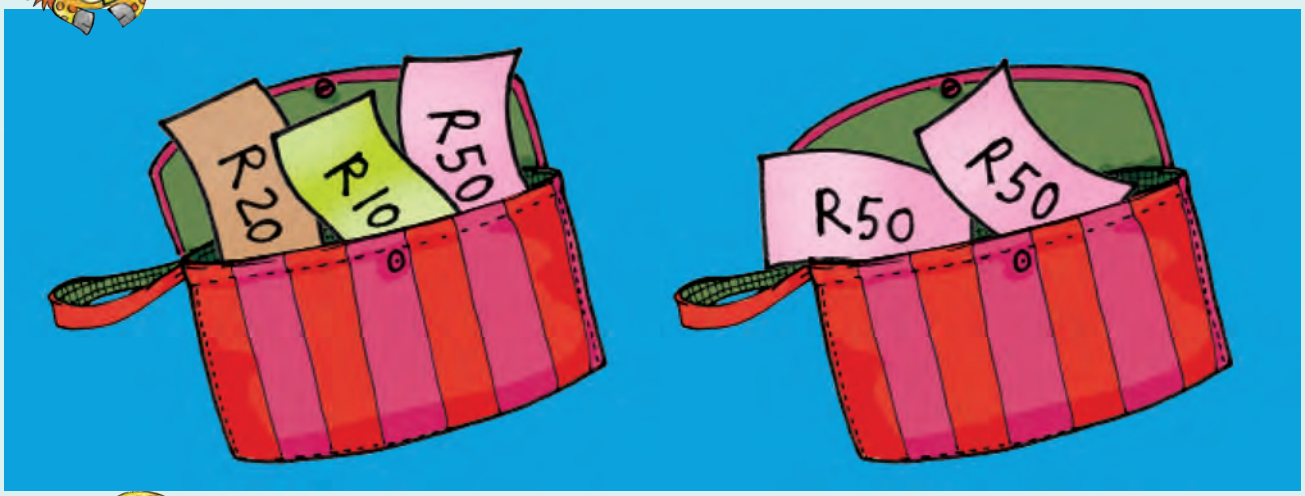

2 Sika imali engamaphepha kumsiko-3 uze uncamathisele imali ef anelekileyo apha.

	
	
	

Zingaphi iirandi?













Izibalo zamazwi:

Ndizigcinele ama-R50. Ndafumana ama-R20 ngosuku lwam lokuzalwa.
Ndinamalini iyonke? _____

Ndinama-R90. Ndithenge incwadi ngama-R30.
Ndinamalini eshiyekileyo? _____

Teacher:
Sign:
Date:

11 12 13 14 15 16 17 18 19 20



Umhla:

Iipatheni

1

Qhwaba ngokulandela isingqi sepatheni.



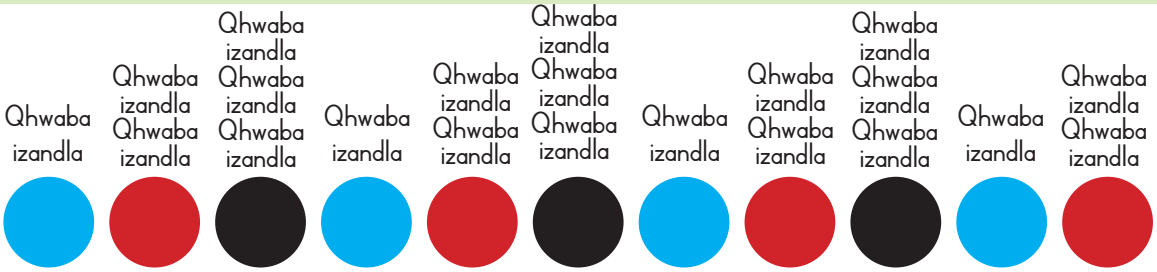

2

Khuphela iipatheni. Sebenzisa umsiko wesi-4.



3

Zenzele umfanekiso wakho ngokusebenzisa amaso ashiyekileyo. Sebenzisa umsiko wesi-4.





Khuphela iipatheni.

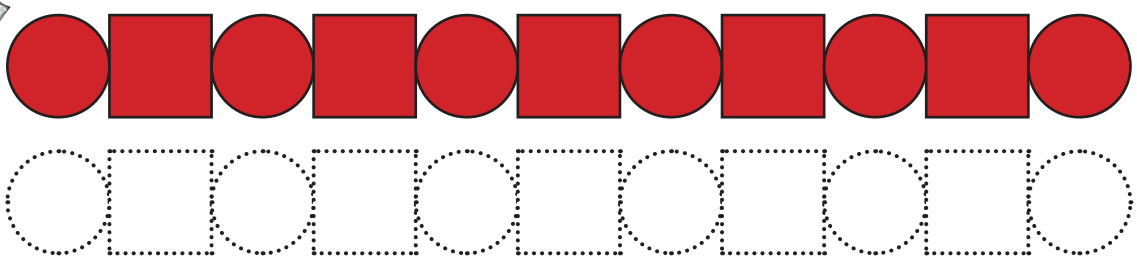



Khuphela iipatheni.





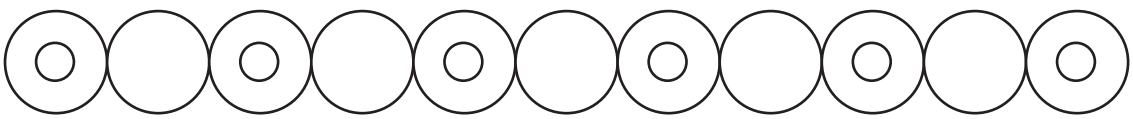

Teacher:

Sign:

Date:

Umhla:

Iipatheni

1

Chaza ipatheni nganye ngamagama. La magama alandelayo angakunceda.



irekthengile | isikwere | unxantathu | isangqa | imibala

2

Faka umbala kwiipatheni ezilandelayo.



3

Zoba ipatheni elandelayo.



4

Yandisa ipatheni.

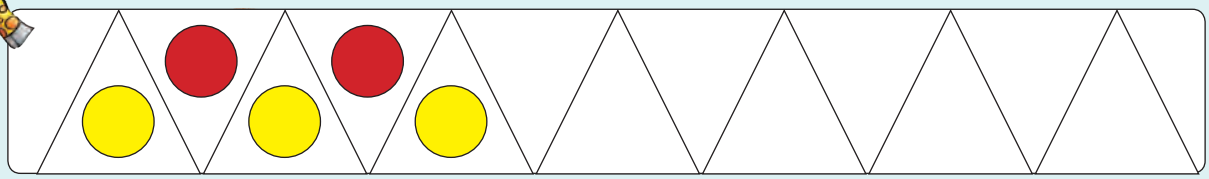

1 2 3 4 5 6 7 8 9 10



Zoba iipatheni zakho usebenzise ezi milo  .

Zoba ipatheni elandelayo.

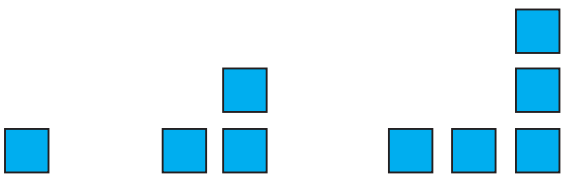



Gqibezela ezi patheni zilandelayo ude usalelwe sisangqa esinye kuphela ngaphezulu.

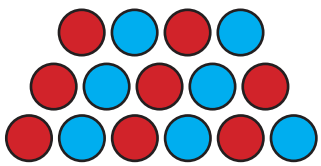

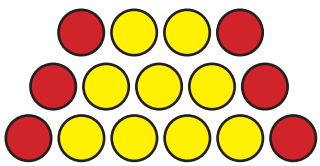

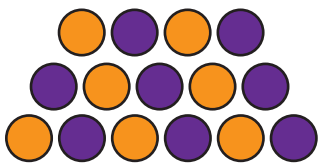

Zenzele iipatheni ezinemibala usebenzise ezi milo zingezantsi.

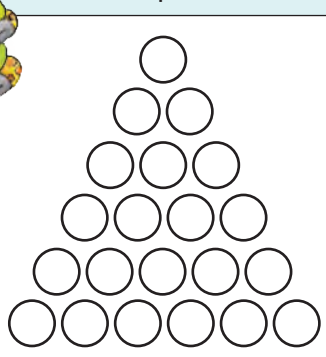

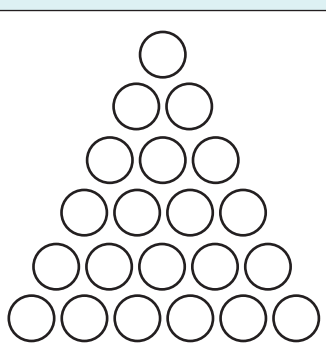

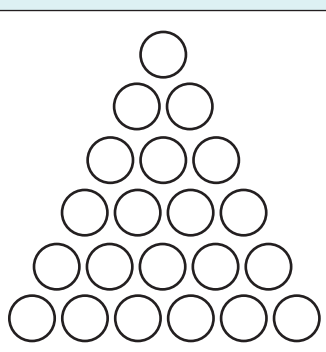

Teacher:
Sign:
Date:



11 12 13 14 15 16 17 18 19 20

Umhla:

Ukuphinda-phinda: x 2

Zingaphi iilekese eziphezu kwetafile nganye?



Uzibale njani iilekese? (Abanye abantwana bangathi 1, 2, 3... abanye bathi 2, 4, 6...)

Gqibezela oku kulandelayo: Sesikwenzele eyokuqala.

amaqela ama-4 ezi-2	2 + 2 + 2 + 2 = 8	4 × 2 = 8
amaqela ama-5 ezi-2	2 + 2 + 2 + 2 + 2 =	5 × 2 =
amaqela ama-6 ezi-2	2 + 2 + 2 + 2 + 2 + 2 =	6 × 2 =
amaqela asi-7 ezi-2	2 + 2 + 2 + 2 + 2 + 2 + 2 =	7 × 2 =
amaqela asi-8 ezi-2	2 + 2 + 2 + 2 + 2 + 2 + 2 + 2 =	8 × 2 =

Zoba oku kulandelayo.

amaqela ama-3 ezi-2	amaqela ama-4 ezi-2	amaqela ali-9 ezi-2



Zoba umfanekiso.

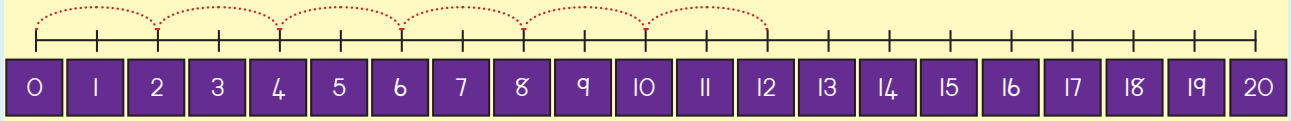

2, 4, 6, 8, ___ , ___

2 + 2 + 2 + 2 + 2 + 2 = ☐

6 × 2 = ☐

Ukuzoba



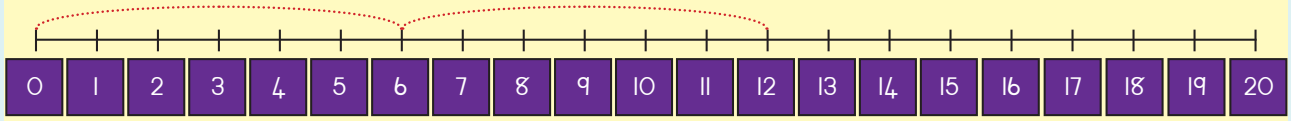

6, ___

6 + ☐ = ☐

2 × ☐ = ☐

Ukuzoba

Isigcawu sinamehlo ama-2. Zinamehlo amangaphi izigcawu ezisi-7?

☐

2 4 6 8 10 12 14

16 18 20 22 24 26

Teacher:

Sign:

Date:



Umhla:

Ukuphinda-phinda: x 5

Zingaphi iilekese eziphezu kwetafile nganye?



Gqibezela oku kulandelayo: Sesikwenzele eyokuqala.

 amaqela ama-3 ezi-5	5 + 5 + 5 = 15	3 × 5 = 15
 amaqela ama-2 ezi-5	5 + 5 =	2 × 5 =
 amaqela ama-4 ezi-5	5 + 5 + 5 + 5 =	4 × 5 =
 amaqela ama-6 ezi-5	5 + 5 + 5 + 5 + 5 + 5 =	6 × 5 =
 amaqela asi-7 ezi-5	5 + 5 + 5 + 5 + 5 + 5 + 5 =	7 × 5 =

Zoba umfanekiso.

amaqela ama-3 ezi-5	amaqela ama-4 ezi-5	amaqela ama-5 ezi-5





Zoba umfanekiso.

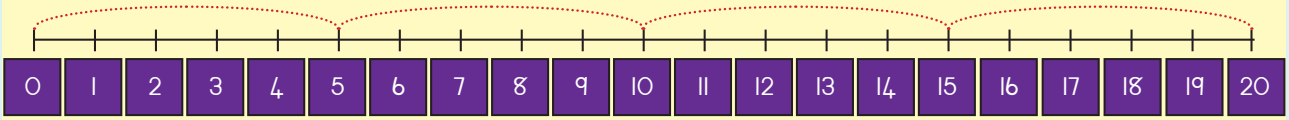

5, 10, 15, ___

5 + 5 + 5 + 5 = ☐

4 × 5 = ☐

Ukuzoba

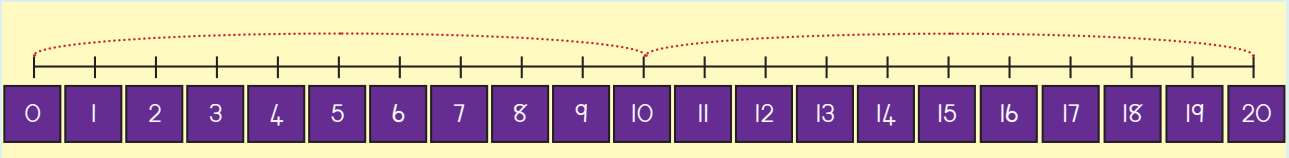

10, ___

10 + ☐ = ☐

10 × ☐ = ☐

Ukuzoba



5 10 15 20 25 30

35 40 45 50

Teacher:

Sign:

Date:



Umhla:

Amanye amabali angophindaphindo

Yenza ibali lakho usebenzise inani leendlebe, izandla neenyawo.



Singabahlobo abali-10. Zingaphi izandla esinazo?

Zoba umfanekiso.

Bonisa impendulo yakho ngesixhobo sokubala.

Bonisa impendulo yakho kumgca-manani.

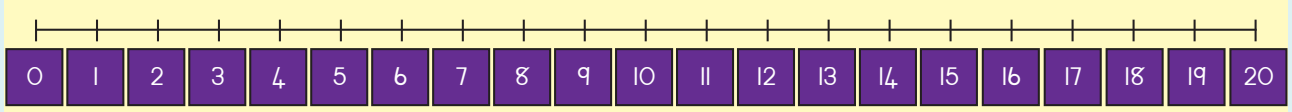

____ + ____ = ____ ____ × ____ = ____





Usapho lukaSusan luneperi ezili-10 zezihlangu. Zingaphi izihlangu zabo zizonke?

Zoba umfanekiso.

Bonisa impendulo yakho ngesixhobo sokubala.

Bonisa impendulo yakho kumgca-manani.

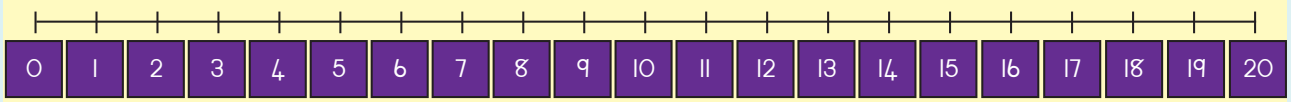



\+ = × =

Bhala ibali lakho usebenzise abantwana aba-6 nezandla zabo.



5 10 15 20 25 30 35

Teacher:
Sign:
Date:

11 12 13 14 15 16 17 18 19 20

Umhla:

Izikwere, iirekthengile, oonxantathu kunye nezangqa (kusaqhutywa)



Fakela imibala ebomvu kwiibhola zonke, iibhokisi zibe bhulowu neesilinda eziluhlaza.

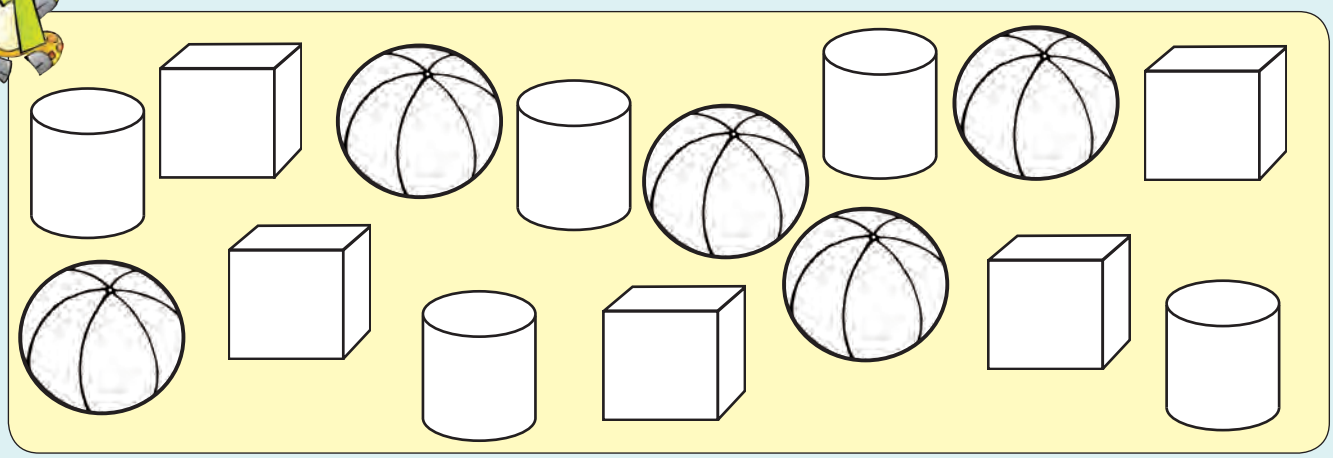

Khetha igama elichanekileyo.

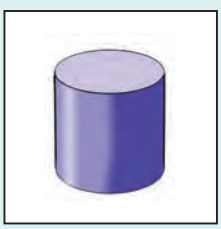

isiphelo esithe ngqo

isiphelo esithe fongqo

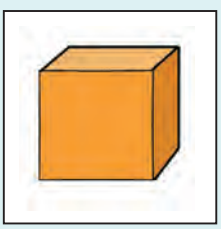

isiphelo esithe ngqo

isiphelo esithe fongqo



isiphelo esithe ngqo

isiphelo esithe fongqo



3

Ingaba le nto ingaqengqeleka okanye ingatyibilika.



iyaqengqeleka

iyatyibilika

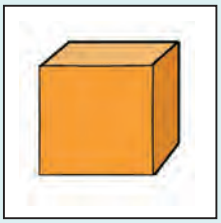

iyaqengqeleka

iyatyibilika



iyaqengqeleka

iyatyibilika

4

Zingaphi izinto ozibonayo kulo mfanekiso: iisilinda, iibhokisi, iibhola?





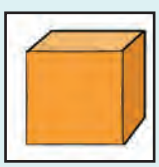



5

Zoba umfanekiso wakho usebenzise iibhola, iibhokisi kunye neetyhubhu.

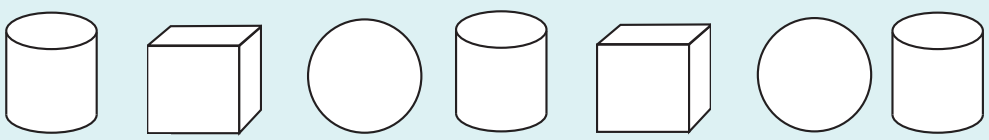

Teacher:

Sign:

Date:

11 12 13 14 15 16 17 18 19 20

Umhla: _____

Lungisa uze uthelekise amanani: 1–40

Ngubani onamaorenji amaninzi?



Ngubani onama-apile amaninzi?



Bala amaso uze ufakele kwiibhokisi ezingenanto.

1	2	3	4	5		7			10
	12				16		18		
21				25	26				30
31					36				40

Jonga amaso uze uphendule imibuzo.

Leliphi inani elingaphantsi kunesi-8? _____

Leliphi inani elingaphezulu kune-13? _____

Leliphi inani elingaphantsi kunama-20? _____

Leliphi inani elingaphantsi kunama-24? _____





Faka umbala obhulowu kumanani angaphantsi kwe-10 uze ufake umbala obomvu kumanani angaphezu kwe-10.

1	2	3	4	5	6	7	8	9	10
11	12	13	14	15	16	17	18	19	20

Faka umbala obhulowu kumanani angaphantsi kwama-30 kodwa engaphezu kwama-24.

20	21	22	23	24	25	26	27	28	29	30

Faka umbala oluhlaza kumanani amancinane kunama-40 namakhulu kunama-36.

30	31	32	33	34	35	36	37	38	39	40

Faka umbala otyheli koonombini uze ufake umbala oluhlaza kumanani ayiminqakathi.

1	2	3	4	5	6	7	8	9	10
11	12	13	14	15	16	17	18	19	20
21	22	23	24	25	26	27	28	29	30
31	32	33	34	35	36	37	38	39	40
41	42	43	44	45	46	47	48	49	50



Ngawaphi amanani ayiminqakathi aza kwangoko emva kwe-10?

Ngawaphi amanani angoonombini aza kwangoko phambi kwe-10?

Bhala phantsi amanani angoonombini aphakathi kwe-14 nama-24.

Bhala phantsi amanani ayiminqakathi aphakathi kwesi-5 kunye ne-15.

Ngawaphi amanani ayiminqakathi aza kwangoko emva kwama-21?

Ngabaphi oonombini abaza kwangoko phambi kwama-24?

Bhala phantsi oonombini abaphakathi kwama-20 kunye nama-30.

Bhala amanani ayiminqakathi aphakathi kwama-20 kunye nama-30.



Teacher:
Sign:
Date:



Umhla: _____

Ukuthelekisa ubukhulu bamanani: 40–50

Ngubani onamapayina amaninzi?











Bala amaso uze uzalise iibhokisi ezingenanto.

1	2	3	4	5					

								19	

							28		

	32								

									50

51	52	53	54	55	56	57	58	59	60

Jonga kula maso uze uphendule imibuzo.

Leliphi inani elincinane kunama-30? _____

Leliphi inani elikhulu kumana-31? _____

Leliphi inani elincinane kunama-38? _____

Leliphi inani elincinane kunama-47? _____



Fakela umbala oluhlaza kumanani angaphantsi kwama-40 nangaphezu kwama-36.

30	31	32	33	34	35	36	37	38	39	40

Amanani amancinane kunama-40.

Amanani amakhulu kunama-36.

Faka umbala otyheli koonombini ufake umbala oluhlaza kumanani ayiminqakathi.

40	41	42	43	44	45	46	47	48	49	50

Leliphi inani elingumnqakathi eliza emva kwama-40?

Leliphi inani elingunombini eliza emva kwama-43?

Bhala phantsi amanani angoonombini aphakathi kwama-40 nama-50?

Bhala phantsi amanani ayiminqakathi aphakathi kwama-40 nama-50?

Leliphi inani elingunombini eliza emva kwama-40?

Leliphi inani elingunombini eliza emva kwama-41?

Teacher:
Sign:
Date:



Umhla: _____

Amanani 40–50



Mangaphi ewonke la maso?

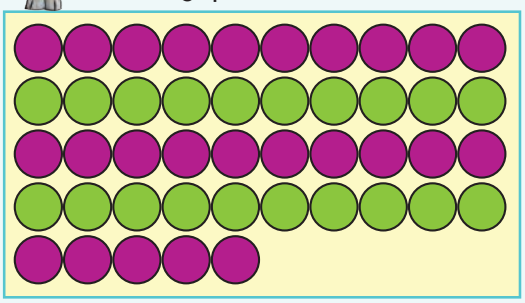

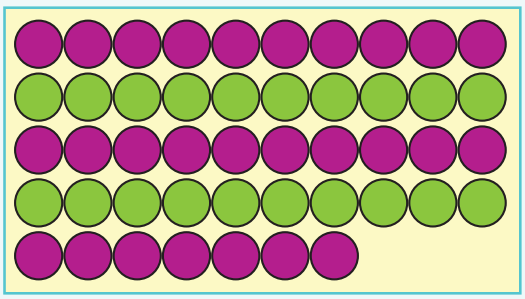

Inani	Singalibhala ngolu hlobo.	Inani	Singalibhala ngolu hlobo.
45	40 + 5 = 45		+ =

Gqibezela oku kulandelayo.

20	21	22							
30				34					
		42							

Gqibezela oku kulandelayo.



20 +  4 = 24



+  =



Bhala amagama ala manani.

41	_____	42	_____
43	_____	44	_____
45	_____	46	_____
47	_____	48	_____
49	_____	50	_____

Jonga kumzekelo wokuqala ugqibezele okuseleyo.

45	=	4	amashumi	+	5	iiyunithi
43	=		amashumi	+		iiyunithi
42	=		amashumi	+		iiyunithi

44	=		amashumi	+		iiyunithi
41	=		amashumi	+		iyunithi
48	=		amashumi	+		iiyunithi

Bhala inani kwikholamu echanekileyo.

	Amashumi	Iiyunithi
27		
34		
46		
41		
39		

Teacher:
Sign:
Date:

11 12 13 14 15 16 17 18 19 20

Umhla: _____

Izikwere, irekthengile, oonxantathu kunye nezangqa

Umakhulu wenze le ngutyana intle. Phawula zonke iimilo ozibonayo kule ngutyana.

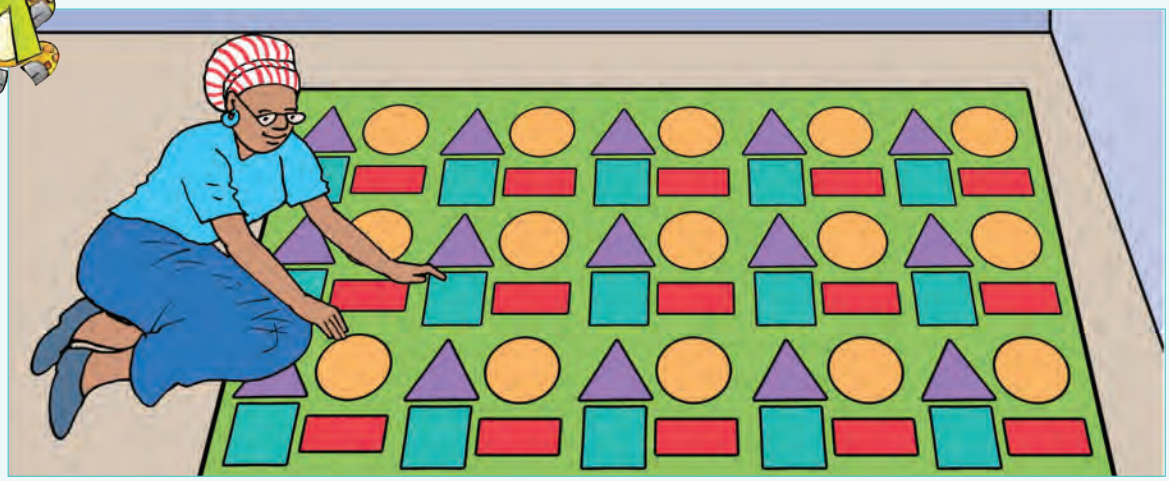

Fakela umbala obhulowu kwizikwere, imibala etyheli kwirekthengile, oluhlaza koonxantathu nobomvu kwizangqa.



Khetha impendulo echanekileyo.



isiphelo esithe ngqo
isiphelo esisicaba



isiphelo esithe ngqo
isiphelo esisicaba



isiphelo esithe ngqo
isiphelo esisicaba



isiphelo esithe ngqo
isiphelo esisicaba



Bala ukuba zingaphi ezi milo kunye ?



Zoba umfanekiso wakho usebenzise izangqa, izikwere, oonxantathu kunye neerekthengile.

Teacher:
Sign:
Date:

11 12 13 14 15 16 17 18 19 20

Umhla:

Izibalo ezixutyiweyo 1–20



Ukuzikhumbuza ngokukhawuleza.

4 + 5 – 1 =	13 – 9 + 2 =	20 – 7 + 1 =	10 + 5 – 4 =
10 + 3 + 2 =	9 + 3 – 2 =	8 – 2 – 1 =	13 – 8 + 1 =
9 – 4 – 3 =	18 – 9 – 4 =	7 + 8 + 1 =	16 – 7 + 3 =
14 – 6 + 4 =	12 – 5 – 2 =	19 – 10 + 5 =	6 + 5 – 3 =



Dibanisa oku kulandelayo.

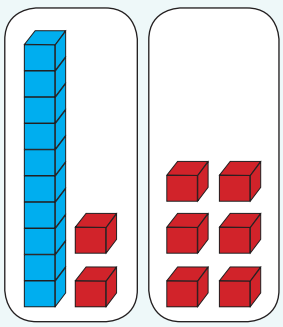

= 10 2 + 6

= 10 + 8

= 18

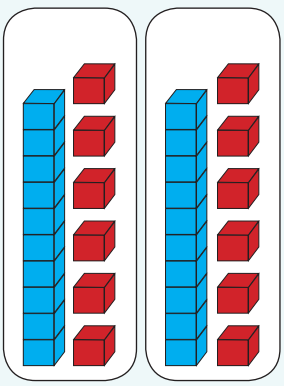

= + + =

= + =

= + =

=

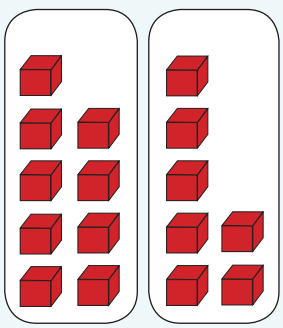

= + =

= + =

=

Thabatha oku kulandelayo.

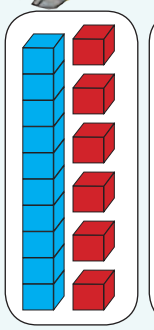

= 10 6 − 4

= 10 − 2

= 8

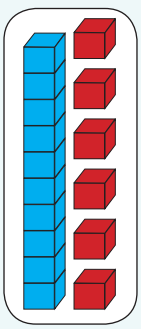

= +

= −

=

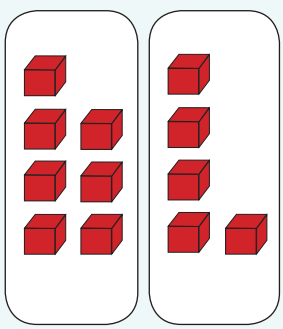

= −

=

Ndithenge iilekese ezili-15.
Ndatya za-2. Ndanika umhlobo wam ezi-4. Ndishiyekelwe ziilekese ezingaphi?



Teacher:
Sign:
Date:

11 12 13 14 15 16 17 18 19 20

Umhla:

Izibalo ezixutyiweyo 20–50



Ukuzikhumbuza ngokukhawuleza.

20 + 2 – 1 =	36 – 6 + 2 =	42 – 2 + 4 =	47 + 4 – 1 =
30 + 3 + 6 =	42 + 9 – 1 =	33 – 2 – 1 =	49 – 1 + 2 =
55 – 5 – 0 =	38 – 7 – 1 =	45 + 1 + 2 =	50 – 5 + 3 =
24 – 3 + 2 =	32 – 5 – 2 =	49 – 10 + 1 =	29 + 5 – 4 =



Dibanisa oku kulandelayo.

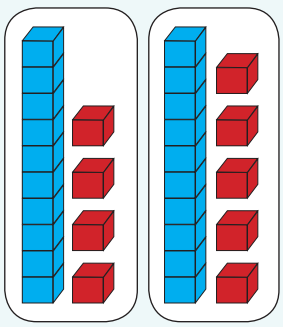

= + +

= +

=

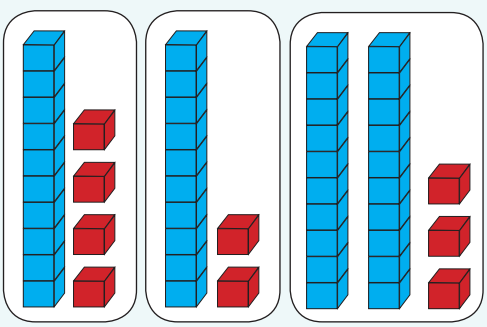

= + +

= +

=

Khawuzame ngeyakho indlela.



1 2 3 4 5 6 7 8 9 10

Thabatha oku kulandelayo.

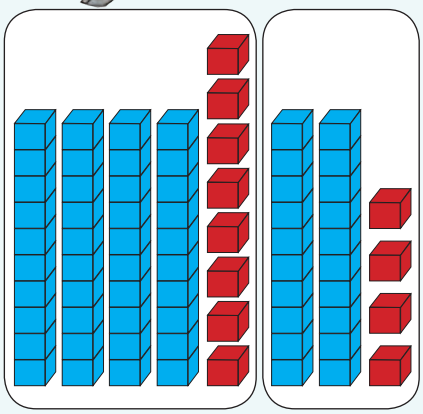

= 40 8 − 20 4

= 40 − 20 + 8 − 4

= ☐ − ☐

= ☐

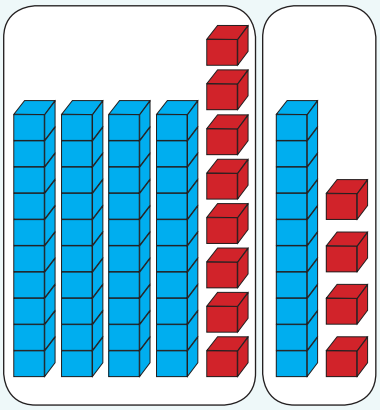

= ☐ ☐ − ☐ ☐

= ☐ − ☐ + ☐ − ☐

= ☐ − ☐

= ☐

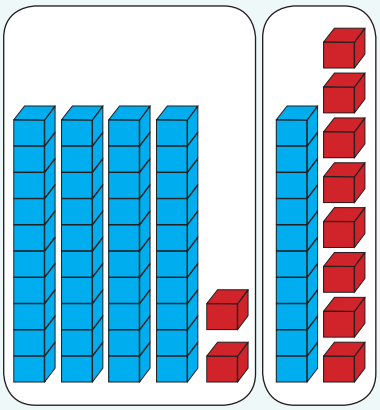

= ☐ ☐ − ☐ ☐

= ☐ − ☐ + ☐ − ☐

= ☐ − ☐

= ☐

Ndine-R10 eliphepha, ingqekembe yee-R5, ama-R20 emali eliphepha kunye nengqekembe yee-R2 kwihagwana yam. Yimalini iyonke imali endiyigcinileyo.



Teacher:
Sign:
Date:

11 12 13 14 15 16 17 18 19 20

Umhla:

Okunye ukudibanisa



Ithini itotali yala manani kwibhokisi nganye?

1 10 5 10	2 10 6 20	3 20 5 20	4 20 4 10



Ukudibanisa.

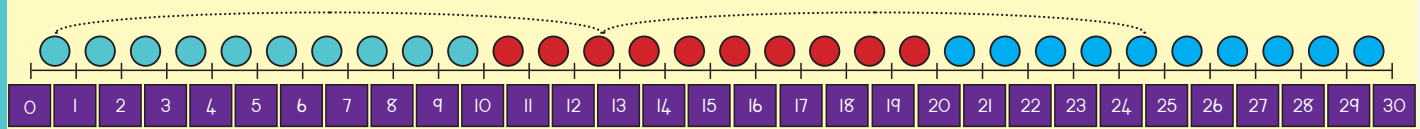

13 + 12 =

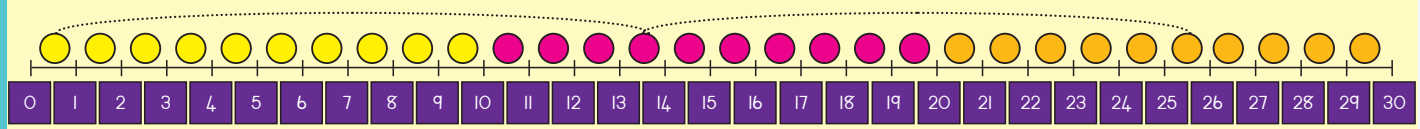

14 + 12 =

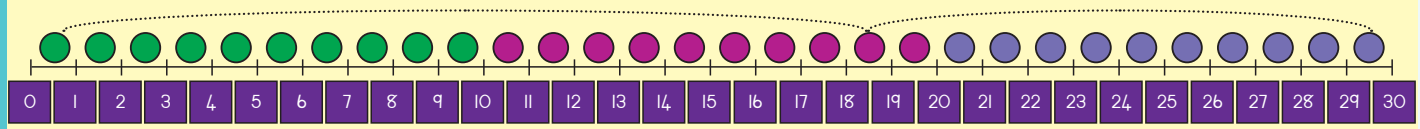

19 + 11 =

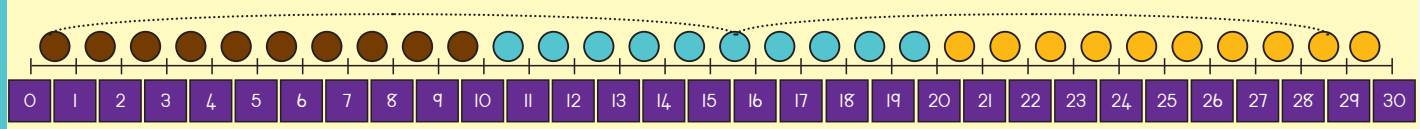

16 + 13 =

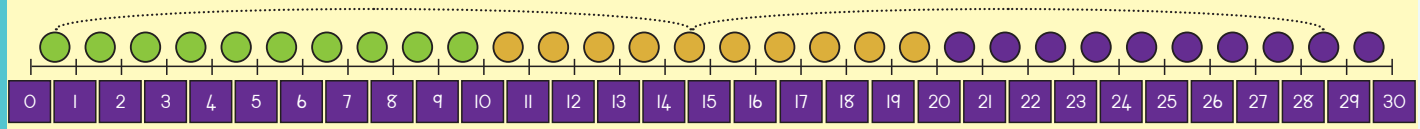

15 + 14 =







Ukudibanisa.

12 + 11

= 10 2 + 10 1

= 10 + 10 + 2 + 1

= 20 + 3

= 23

13 + 15

= ☐☐ + ☐☐

= ☐ + ☐ + ☐ + ☐

= ☐ + ☐

= ☐

26 + 12

= ☐☐ + ☐☐

= ☐ + ☐ + ☐ + ☐

= ☐ + ☐

= ☐

23 + 22

= ☐☐ + ☐☐

= ☐ + ☐ + ☐ + ☐

= ☐ + ☐

= ☐

24 + 13

= ☐☐ + ☐☐

= ☐ + ☐

= ☐

35 + 12

= ☐☐ + ☐☐

= ☐ + ☐

= ☐



UBetty uthenge iilekese zama-R36 uSipho wathenga eze-R13. Bachithe malini ezilekeseni?

Teacher:

Sign:

Date:



Umhla:

Okunye ukudibanisa (kusaqhutywa)



Ithini itotali yala manani kwibhokisi nganye?

12 + 10 = ☐

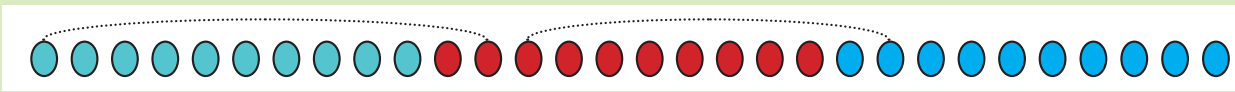

15 + 10 = ☐

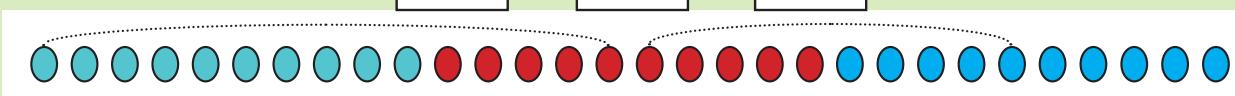

19 + 10 = ☐





Zoba onke amaso aseleyo uze ugqibezele ukubala.

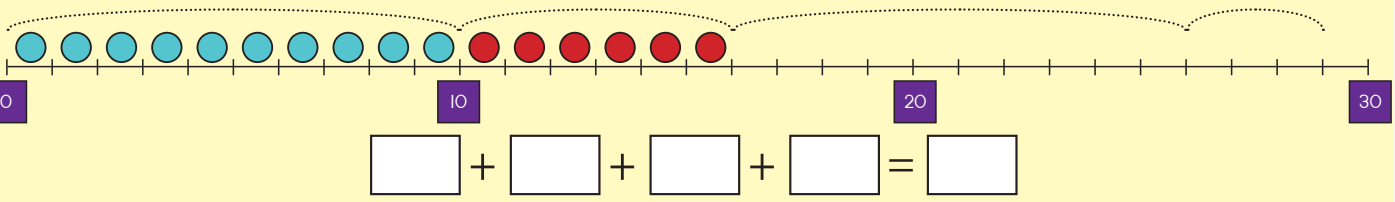

☐ + ☐ + ☐ + ☐ = ☐

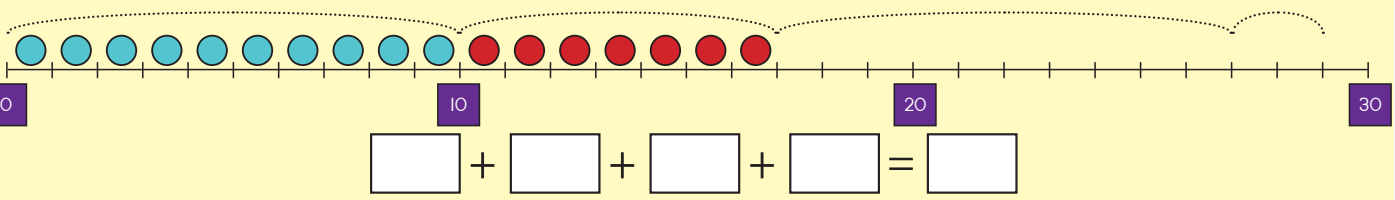

☐ + ☐ + ☐ + ☐ = ☐

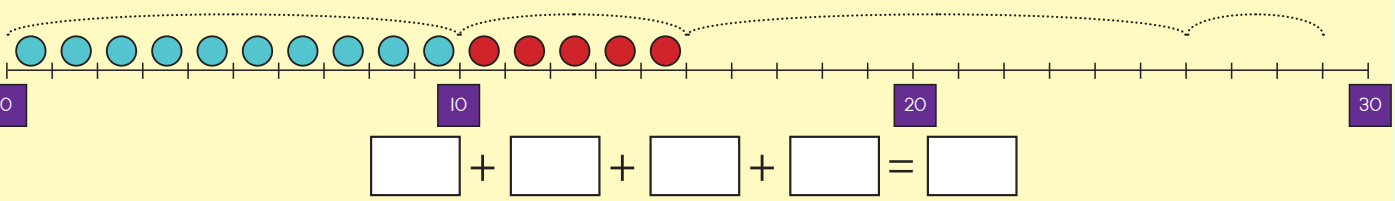

☐ + ☐ + ☐ + ☐ = ☐

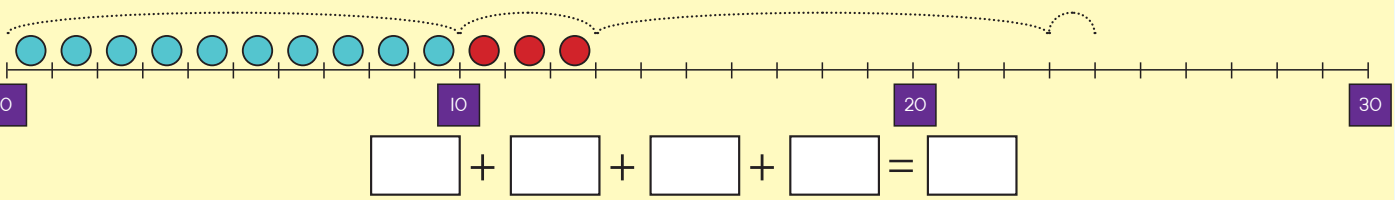

☐ + ☐ + ☐ + ☐ = ☐



1 2 3 4 5 6 7 8 9 10



Gqibezela.

28	+	11	=	2	8	+	10	+	1	=	38	+	1	= 39
34	+	12	=	3	4	+	10	+	2	=		+		=
23	+	13	=	2	3	+	10	+	3	=		+		=
35	+	12	=	3	5	+	10	+	2	=		+		=
26	+	11	=	2	6	+	10	+	1	=		+		=

Ukudibanisa.

11 + 10 =	23 + 10 =	36 + 10 =
28 + 10 =	37 + 10 =	12 + 10 =
34 + 10 =	29 + 10 =	15 + 10 =

Sithini isiphumo xa udibanise isi-7 kunye nesi-6?
Yibonakalise ngokuzoba impendulo yakho.

Zenzele ezakho izivakalisi manani ngokusebenzisa imifanekiso.

Teacher:
Sign:
Date:

11 12 13 14 15 16 17 18 19 20

Umhla:

Ubude



Faka kwiimpendulo zakho umbala ofana nalowo weebhloko.

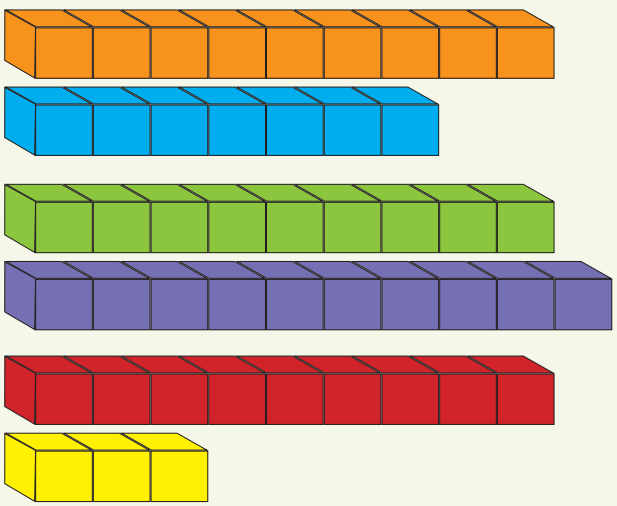

imfutshane	inde
imfutshane	inde
imfutshane	inde

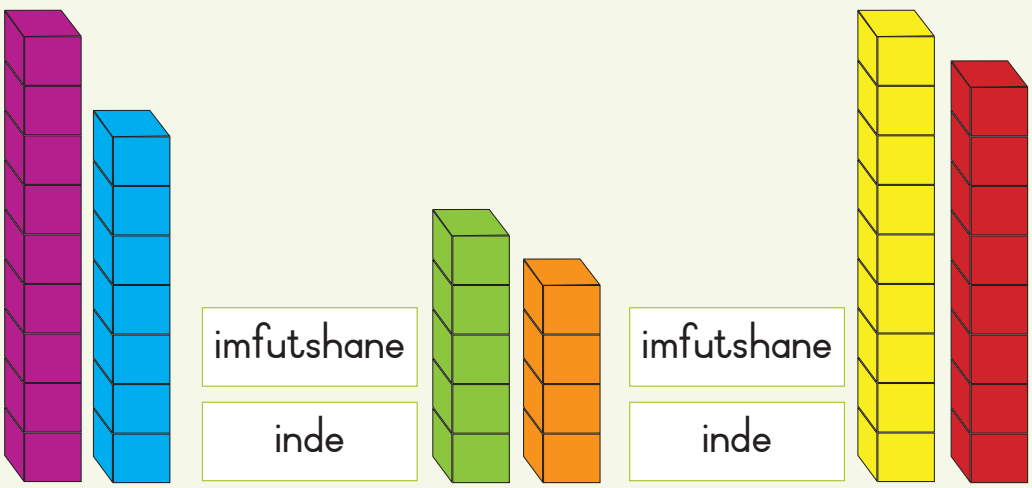

imfutshane	imfutshane	imfutshane
inde	inde	inde

Faka kwiimpendulo umbala ofana nalowo weshoti wenkwenkwe.



mfutshane | mde



mfutshane | mde



mfutshane | mde

Linganisa amacala ebala lokudlala ngesandla nangonyawo olusike kumsiko woku-1.

Zizandla ezingaphi ubude bebala lokudlala.

Ziinyawo ezingaphi ubude bebala lokudlala.

ubude



Teacher:
Sign:
Date:

11 12 13 14 15 16 17 18 19 20

Umhla: _____

Ukuthabatha (kusaqhutywa)



Thelekisa la makhasi.

10	10	10	10	10
2 2	8 8	7 7	5 5	3 3
17 – 7 = 10	12 – 2 = 10	15 – 5 = 10	13 – 3 = 10	18 – 8 = 10



Sebenzisa umgca-manani. Thabatha.

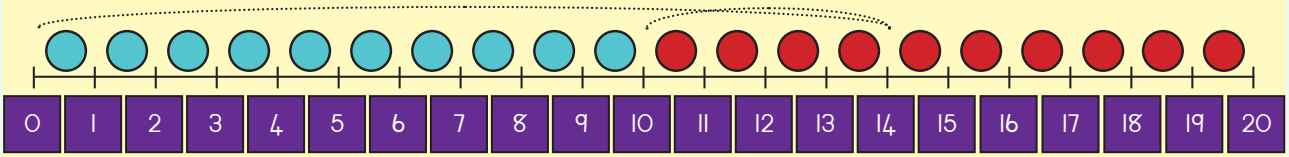

14 – 4 = 10

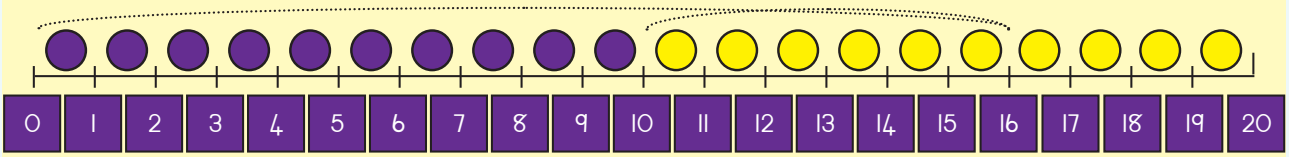

_____ – _____ = _____

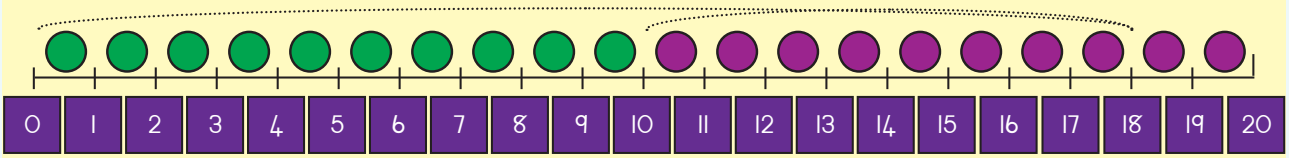

_____ – _____ = _____

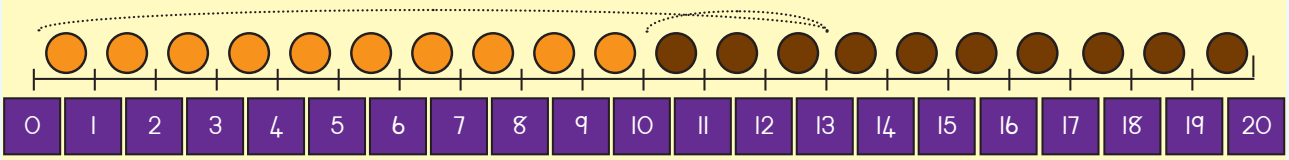

_____ – _____ = _____





Ukuthabatha.

10	3	−	3	=		10	2	−	2	=	
10	5	−	5	=		10	7	−	7	=	
10	1	−	1	=		10	6	−	6	=	
10	4	−	4	=		10	8	−	8	=	
10	9	−	9	=		10	9	−	5	=	



Ukuthabatha.

16 − 13

10	10		0	
6	3	=	3	
16	−	13	=	3

14 − 12

10	10			
4	2	=		
14	−	12	=	

27 − 11

20	10			
7	1	=		
	−		=	

35 − 13

30	10			
5	3	=		
	−		=	

26 − 12

20	10			
6	2	=		
	−		=	

48 − 11

40	10			
8	1	=		
	−		=	



ULisa unezixhobo zokubala ezili-17. Ulahlekelwe zezisi-8.





Zingaphi izixhobo ashiyekelelwe zizo?

Teacher:
Sign:
Date:

11 12 13 14 15 16 17 18 19 20



Okunye ukuthabatha

Thabatha amanani angezantsi kumanani angentla.

10 − 7 = 17	20 − 2 =	30 − 8 =	40 − 9 =
10 − 5 = 15	10 − 1 =	10 − 5 =	10 − 4 =
2			

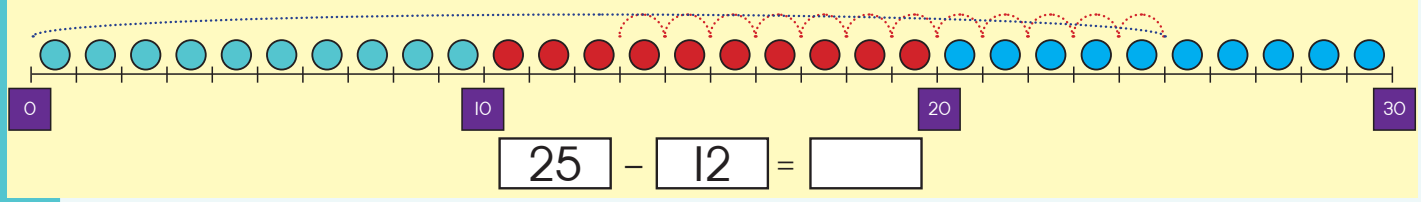

25 − 12 = ☐

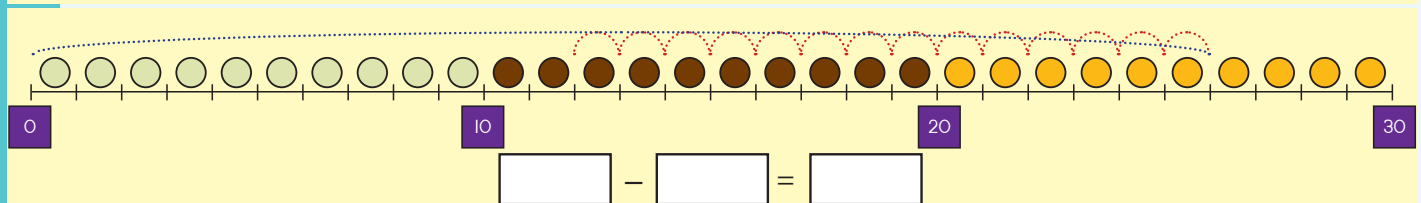

☐ − ☐ = ☐

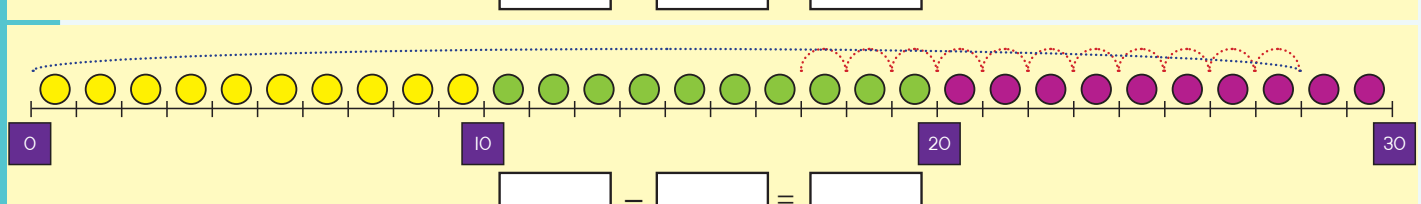

☐ − ☐ = ☐

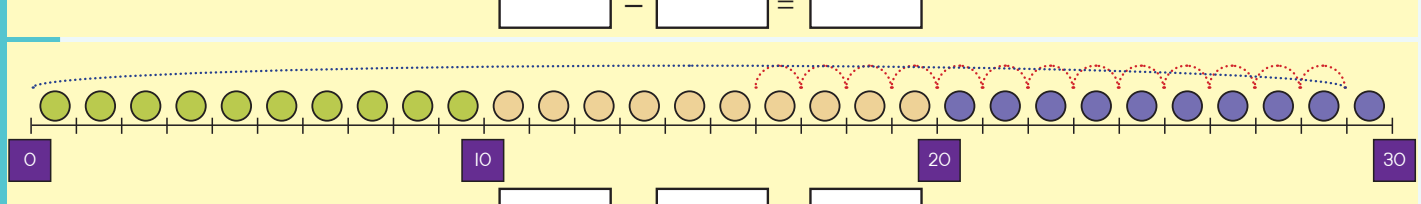

☐ − ☐ = ☐

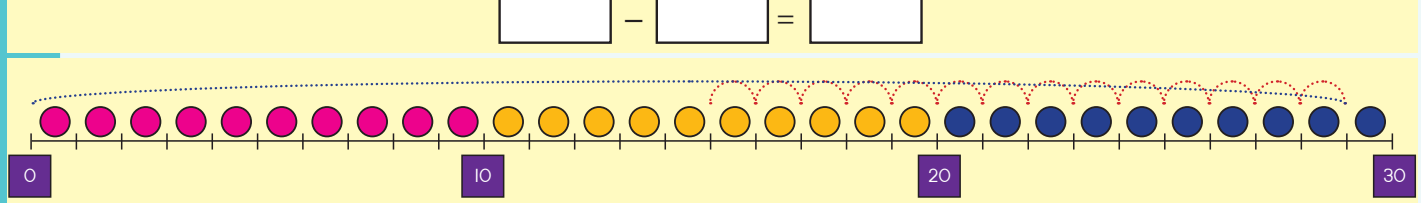

☐ − ☐ = ☐







Ukuthabatha.

45 – 23

= 40 [ ] – 20 3

= 40 – 20 + 5 – 3

= 20 + 2

= 22

38 – 16

= [ ] [ ] – [ ] [ ]

= [ ] – [ ] + [ ] – [ ]

= [ ] + [ ]

= [ ]

29 – 14

= [ ] [ ] – [ ] [ ]

= [ ] – [ ] + [ ] – [ ]

= [ ] + [ ]

= [ ]

48 – 11

= [ ] [ ] – [ ] [ ]

= [ ] – [ ] + [ ] – [ ]

= [ ] + [ ]

= [ ]

35 – 23

= [ ] [ ] – [ ] [ ]

= [ ] – [ ] + [ ] – [ ]

= [ ] + [ ]

= [ ]

38 – 15

= [ ] [ ] – [ ] [ ]

= [ ] – [ ] + [ ] – [ ]

= [ ] + [ ]

= [ ]



Teacher:

Sign:

Date:



42b

Umhla: _____

Okunye ukuthabatha (kusaqhutywa)

1 Ithini itotali yala manani kwibhokisi nganye?

22 – 10 = ☐

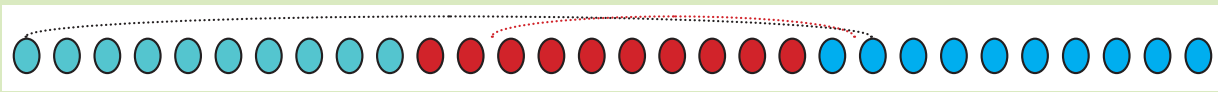

25 – 10 = ☐

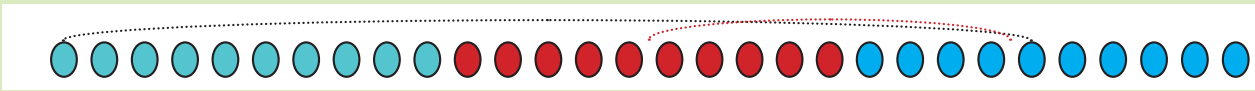

29 – 10 = ☐



2 Gqibezela ezi zibalo.

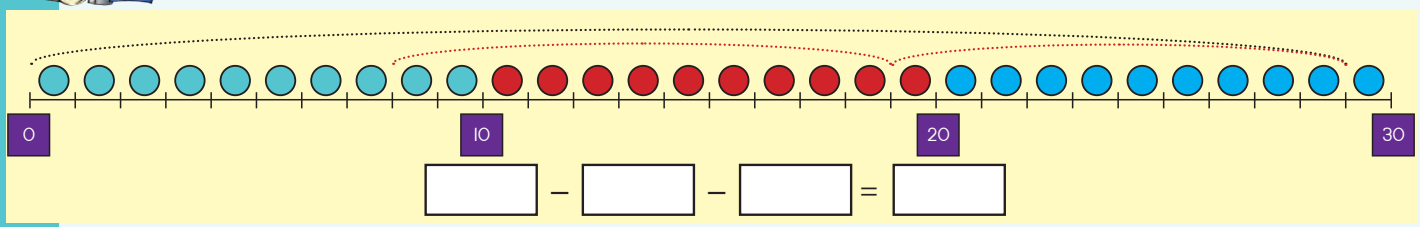

☐ – ☐ – ☐ = ☐

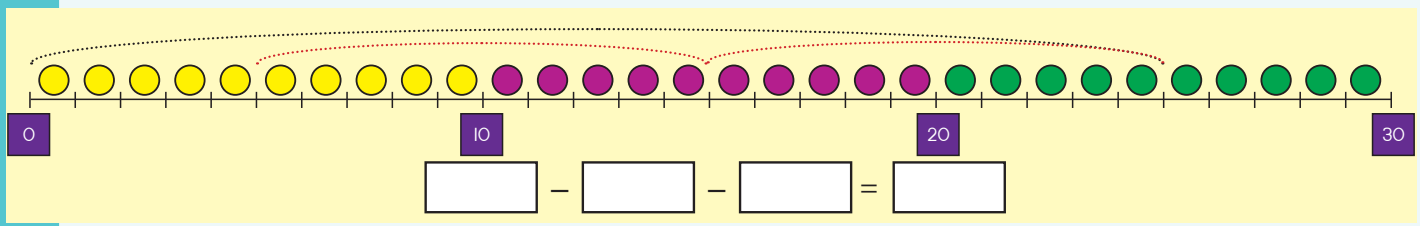

☐ – ☐ – ☐ = ☐

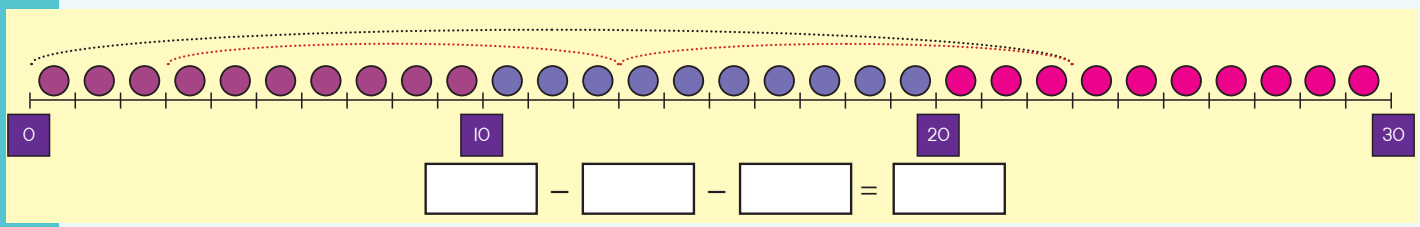

☐ – ☐ – ☐ = ☐

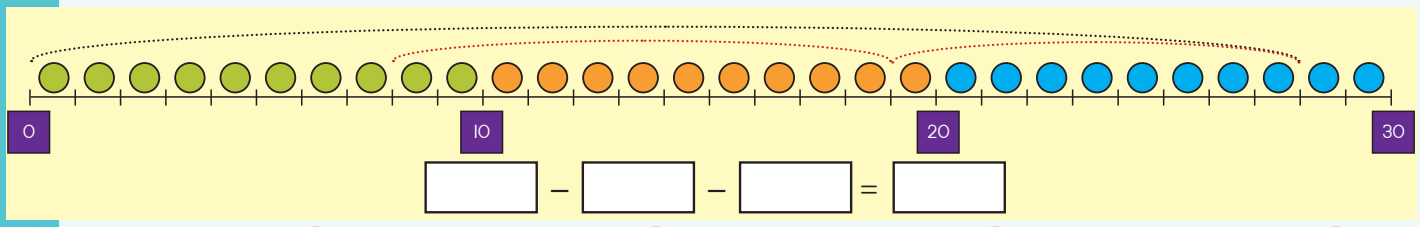

☐ – ☐ – ☐ = ☐

1 2 3 4 5 6 7 8 9 10





Gqibezela.

46	38	25
– 13	– 14	– 11

49	27	46
– 23	– 16	– 32



Ukuthabatha.

21 – 10 =	43 – 10 =	16 – 10 =
28 – 10 =	27 – 10 =	22 – 10 =
34 – 10 =	37 – 10 =	45 – 10 =



Sithini isiphumo xa uthabathe ama-20 kuma-35? Zoba umfanekiso ubonise impendulo yakho.

3 5 – 2 0 = _____



Zenzele isivakalisi-manani usebenzise imifanekiso.

[ ] – [ ] = [ ]



Teacher:

Sign:

Date:



Umhla:

Enzima kunye nekhaphu-khaphu

1 Jonga emifanekisweni uphendule umbuzo.

Yeyiphi eyona ikhaphu-khaphu ze ibe yeyiphi eyona inzima?





2 Ncamathisela okanye zoba imifanekiso yezi zinto:

Izinto ezinzima	Izinto ezikhaphu-khaphu



Umbala otyheli ubonisa into ekhaphu-khaphu ze obhulowu ubonise into enzima. Bhala ikhaphu-khaphu okanye inzima.



ikhaphu-khaphu











Zoba okanye ncamathisela izinto ngokwale nto iboniswa sisikali.

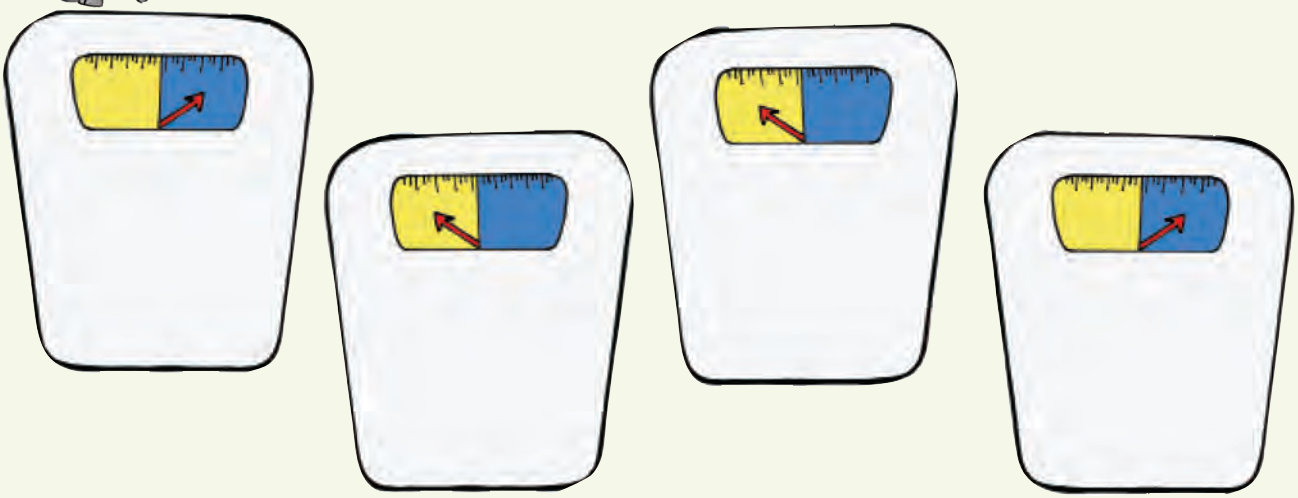

Umhla: _____

Iipatheni zamanani: izibini

1 Masibale ngezibini.





2 Zoba okanye uncamathisele imifanekiso yezinto ezime ngambini.

3 Sikuqalele ipatheni. Yigqibezele.

1	2	3	4	5	6	7	8	9	10
11	12	13	14	15	16	17	18	19	20
21	22	23	24	25	26	27	28	29	30
31	32	33	34	35	36	37	38	39	40
41	42	43	44	45	46	47	48	49	50
51	52	53	54	55	56	57	58	59	60
61	62	63	64	65	66	67	68	69	70
71	72	73	74	75	76	77	78	79	80
81	82	83	84	85	86	87	88	89	90
91	92	93	94	95	96	97	98	99	100



Sebenzisa imigca - manani ukubhala ipatheni.

0 1 2 3 4 5 6 7 8 9 10

2 4 6 8 10

10 11 12 13 14 15 16 17 18 19 20

20 21 22 23 24 25 26 27 28 29 30

0 1 2 3 4 5 6 7 8 9 10



Qgibezela oku kulandelayo:

2, 4, 6, __ , __ , __	13, 15, 17, __ , __ , __	26, 24, 22, __ , __ , __
62, 64, 66, __ , __ , __	55, 57, 59, __ , __ , __	9, 7, 5, __ , __ , __
44, 46, 48, __ , __ , __	10, 8, 6, __ , __ , __	29, 27, 25, __ , __ , __
1, 3, 5, __ , __ , __	98, 96, 94, __ , __ , __	95, 93, 91, __ , __ , __



2 4 6 8 10 12 14 16 18 20

Teacher:
Sign:
Date:

11 12 13 14 15 16 17 18 19 20

Umhla: _____

Okuphinda-phindwe kabini

1 Jonga kwitafile yokuqala neyesibini. Kwenzeke ntoni?





2 Dibanisa amachaphaza, uze ubhale isiphumo sempendulo nganye.

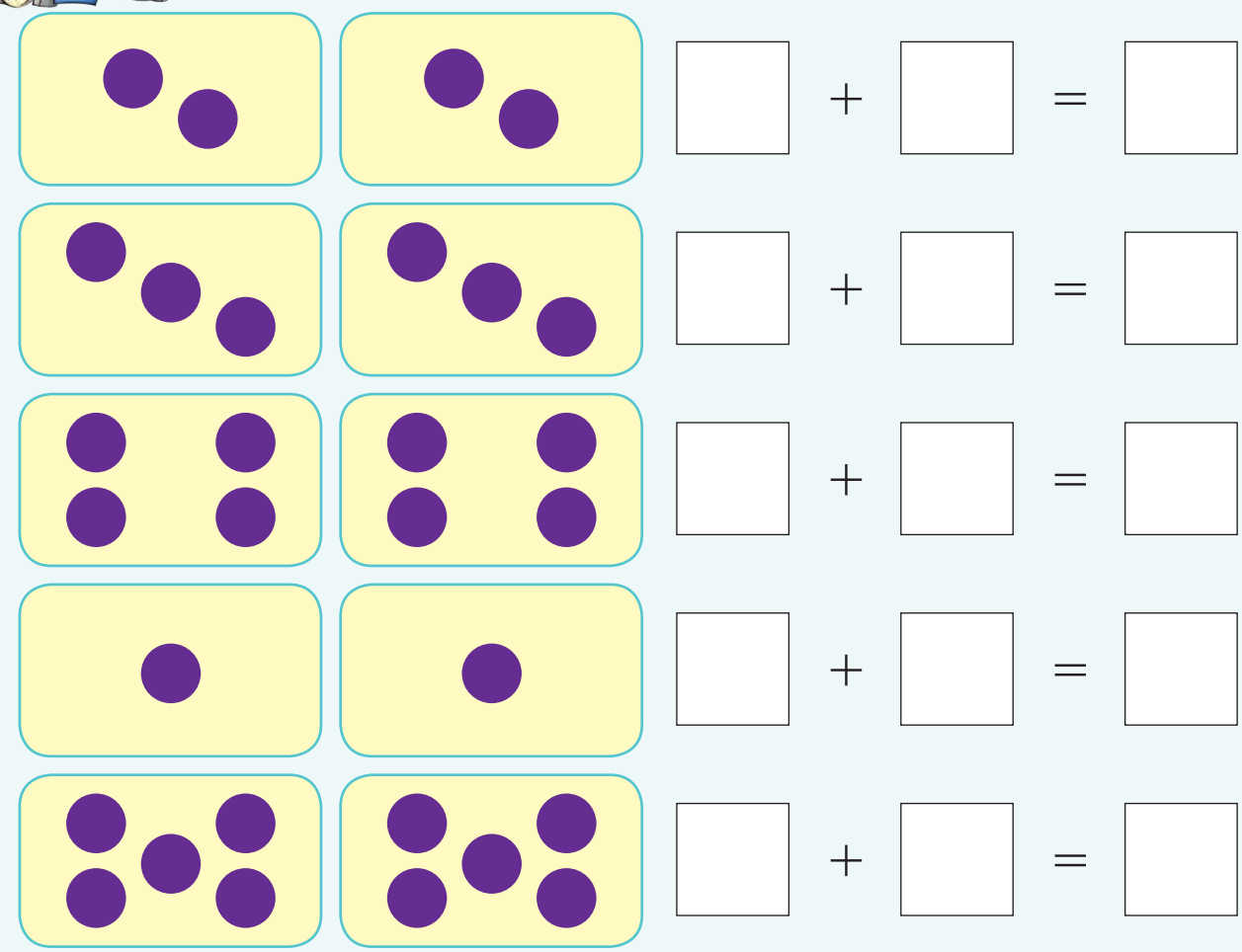

Sebenzisa imigca-manani ukubhala impendulo.

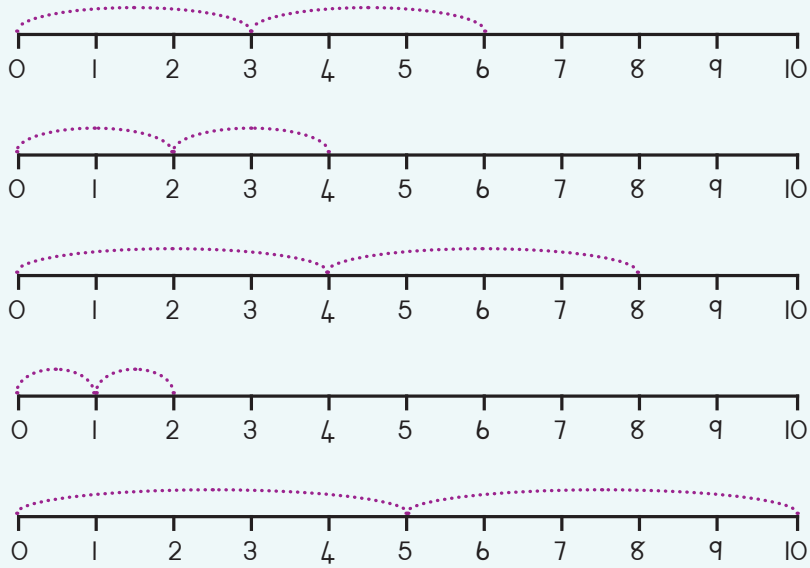

	+		=	
	+		=	
	+		=	
	+		=	
	+		=	

Phinda-phinda kabini oku kulandelayo:

Phinda-phinda u-1 kabini	1	+	1	=	2	2	×	1	=	2
Phinda-phinda isi-2 kabini		+		=		2	×		=	
Phinda-phinda isi-3 kabini		+		=		2	×		=	
Phinda-phinda isi-4 kabini		+		=		2	×		=	
Phinda-phinda isi-5 kabini		+		=		2	×		=	

Ndinee-R5. Umhlobo wam yena unale yam iphindwe kabini. Unamalini umhlobo wam?

Teacher:
Sign:
Date:

11 12 13 14 15 16 17 18 19 20

Umhla:

Phinda kabini kwakhona

Jonga itafile yokuqala neyesibini. Kwenzeke ntoni?



Dibanisa amachaphaza, uze ubhale isiphumo sempendulo nganye.

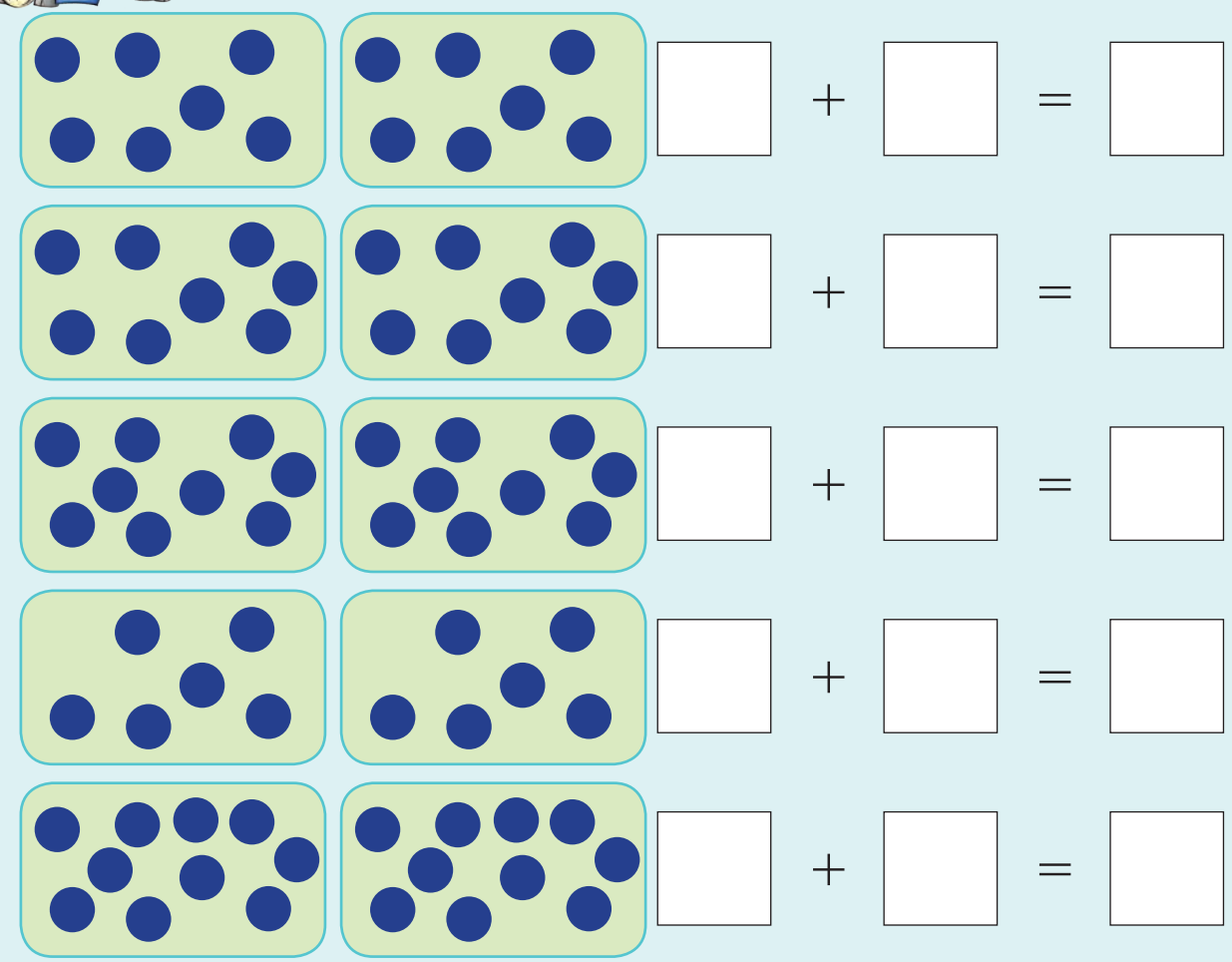



Sebenzisa imigca-manani ukubhala impendulo.

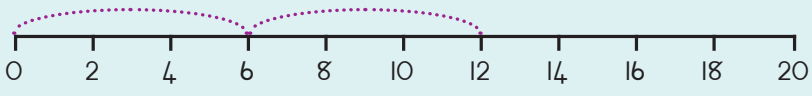

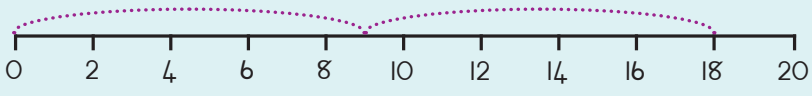

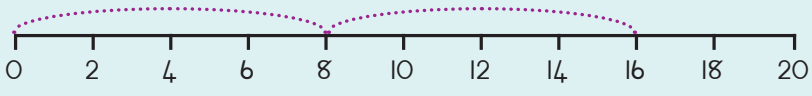

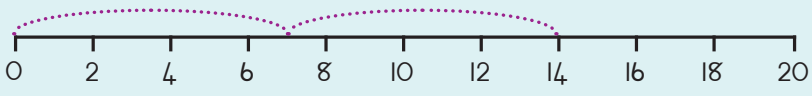

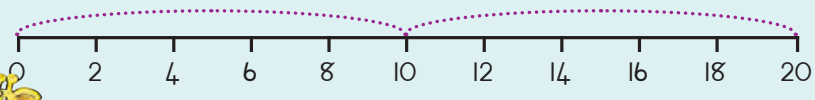

		+		=				
		+		=				
		+		=				
		+		=				
		+		=				

Phinda-phinda kabini oku kulandelayo:

Phinda-phinda isi-6 kabini		+		=		2	×	6	=	12
Phinda-phinda isi-7 kabini		+		=		2	×		=	
Phinda-phinda isi-8 kabini		+		=		2	×		=	
Phinda-phinda i-9 kabini		+		=		2	×		=	
Phinda-phinda i-10 kabini		+		=		2	×		=	

Umhlobo wam unamapetyu ali-9. Mna ndiwaphinda kabini awakhe. Mangaphi amapetyu endinawo?

Teacher:
Sign:
Date:



Umhla: _____

Phinda kabini kwakhona

Phinda-phinda kabini isi-8

1 2 3 4 5 6 7 8 1 2 3 4 5 6 7 8

1 2 3 4 5 6 7 8 9 10 11 12 13 14 15 16

Phinda-phinda kabini i-9

1 2 3 4 5 6 7 8 9 1 2 3 4 5 6 7 8 9

1 2 3 4 5 6 7 8 9 10 11 12 13 14 15 16 17 18



Sebenzia amaso ukuphinda kabini amanani. Sikuqalele umzekelo wokuqala.

Phinda-phinda kabini isi-5



Phinda-phinda kabini isi-6

5 + 5 = ☐



☐ + ☐ = ☐

Phinda-phinda kabini isi-7



☐ + ☐ = ☐

Phinda-phinda kabini isi-8



☐ + ☐ = ☐

Phinda-phinda kabini i-9



☐ + ☐ = ☐



Phinda-phinda kabini amanani. Faka umbala kwimpendulo yakho.

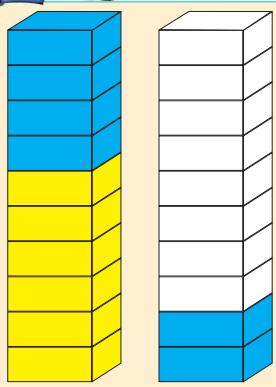

Phinda-phinda kabini isi-6

6 + 6 = ☐

2 × 6 = ☐

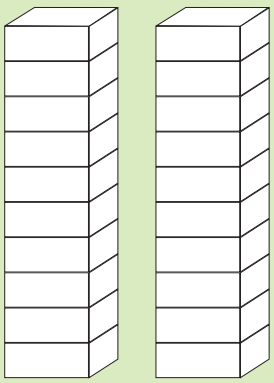

Phinda-phinda kabini isi-8

☐ + ☐ = ☐

2 × ☐ = ☐

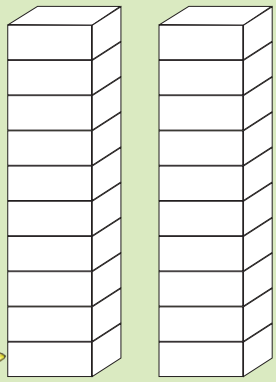

Phinda-phinda kabini isi-7

☐ + ☐ = ☐

2 × ☐ = ☐

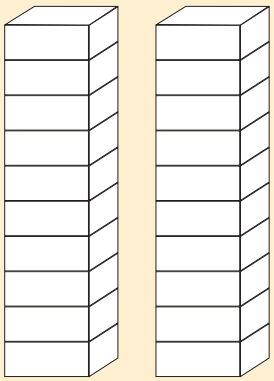

Phinda-phinda kabini i-9

☐ + ☐ = ☐

2 × ☐ = ☐

Phinda-phinda kabini oku kulandelayo:

Phinda-phinda isi-7 kabini	☐ + ☐ = ☐	2 × ☐ = ☐
Phinda-phinda i-9 kabini	☐ + ☐ = ☐	2 × ☐ = ☐
Phinda-phinda isi-6 kabini	☐ + ☐ = ☐	2 × ☐ = ☐
Phinda-phinda isi-8 kabini	☐ + ☐ = ☐	2 × ☐ = ☐
Phinda-phinda i-10 kabini	☐ + ☐ = ☐	2 × ☐ = ☐

Ndingenise amanqaku asi-8. Umhlobo wam wangenisa ngokuphindwe kabini. Mangaphi amanqaku omhlobo wam?

Teacher:
Sign:
Date:



Umhla:

Okunye ukuphinda kabini

Phinda-phinda kabini i-12

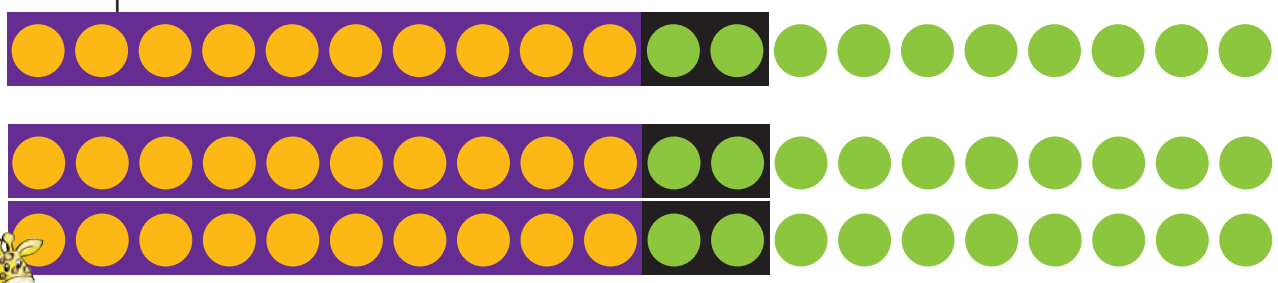



Sebenzisa amaso ukuphinda-phinda kabini amanani. Sikuqalele umzekelo wokuqala.

Phinda-phinda kabini i-13

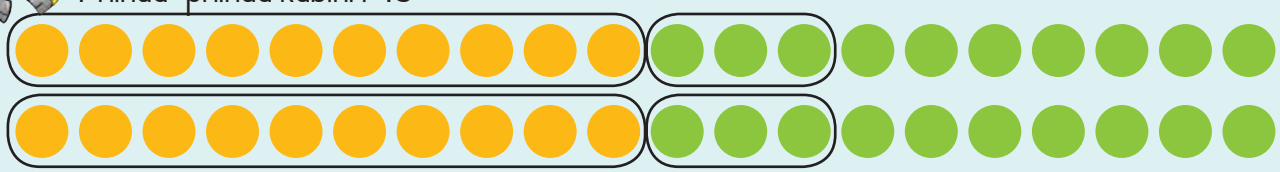

Phinda-phinda kabini i-15 ☐ + ☐ = ☐

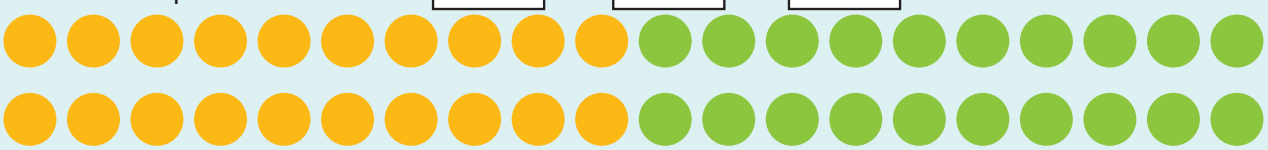

Phinda-phinda kabini i-14 ☐ + ☐ = ☐



Phinda-phinda kabini i-11 ☐ + ☐ = ☐



Phinda-phinda kabini i-16 ☐ + ☐ = ☐



☐ + ☐ = ☐



Phinda-phinda kabini amanani. Faka umbala kwimpendulo yakho.

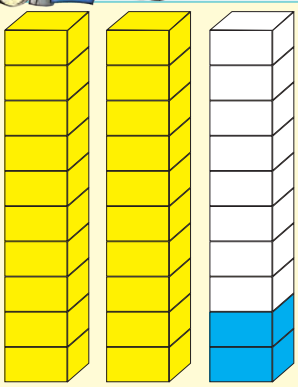

Phinda-phinda kabini i-11

11 + 11 = ☐

2 × 11 = ☐



Phinda-phinda kabini i-13

☐ + ☐ = ☐

2 × ☐ = ☐

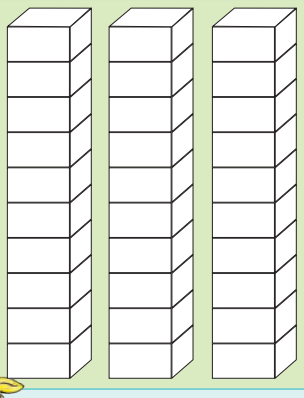

Phinda-phinda kabini i-14

☐ + ☐ = ☐

2 × ☐ = ☐



Phinda-phinda kabini i-15

☐ + ☐ = ☐

2 × ☐ = ☐

Phinda-phinda kabini oku kulandelayo:

Phinda-phinda i-11 kabini	☐ + ☐ = ☐	2 × ☐ = ☐
Phinda-phinda i-13 kabini	☐ + ☐ = ☐	2 × ☐ = ☐
Phinda-phinda i-16 kabini	☐ + ☐ = ☐	2 × ☐ = ☐
Phinda-phinda i-17 kabini	☐ + ☐ = ☐	2 × ☐ = ☐
Phinda-phinda i-18 kabini	☐ + ☐ = ☐	2 × ☐ = ☐

Nditye iibhiskithi ezili-14 kukhuphiswano lweebhisikithi. Ophumeleleyo utye eli nani liphindiwe kabini. Utye iibhisikithi ezingaphi zizonke?

Teacher:

Sign:

Date:

11 12 13 14 15 16 17 18 19 20

Umhla:

Izikhongozeli kunye nomthamo

Ncokola ngezikhongozeli ezisezidesikeni.



Xela ukuba isikhongozeli sizele na okanye asinanto.

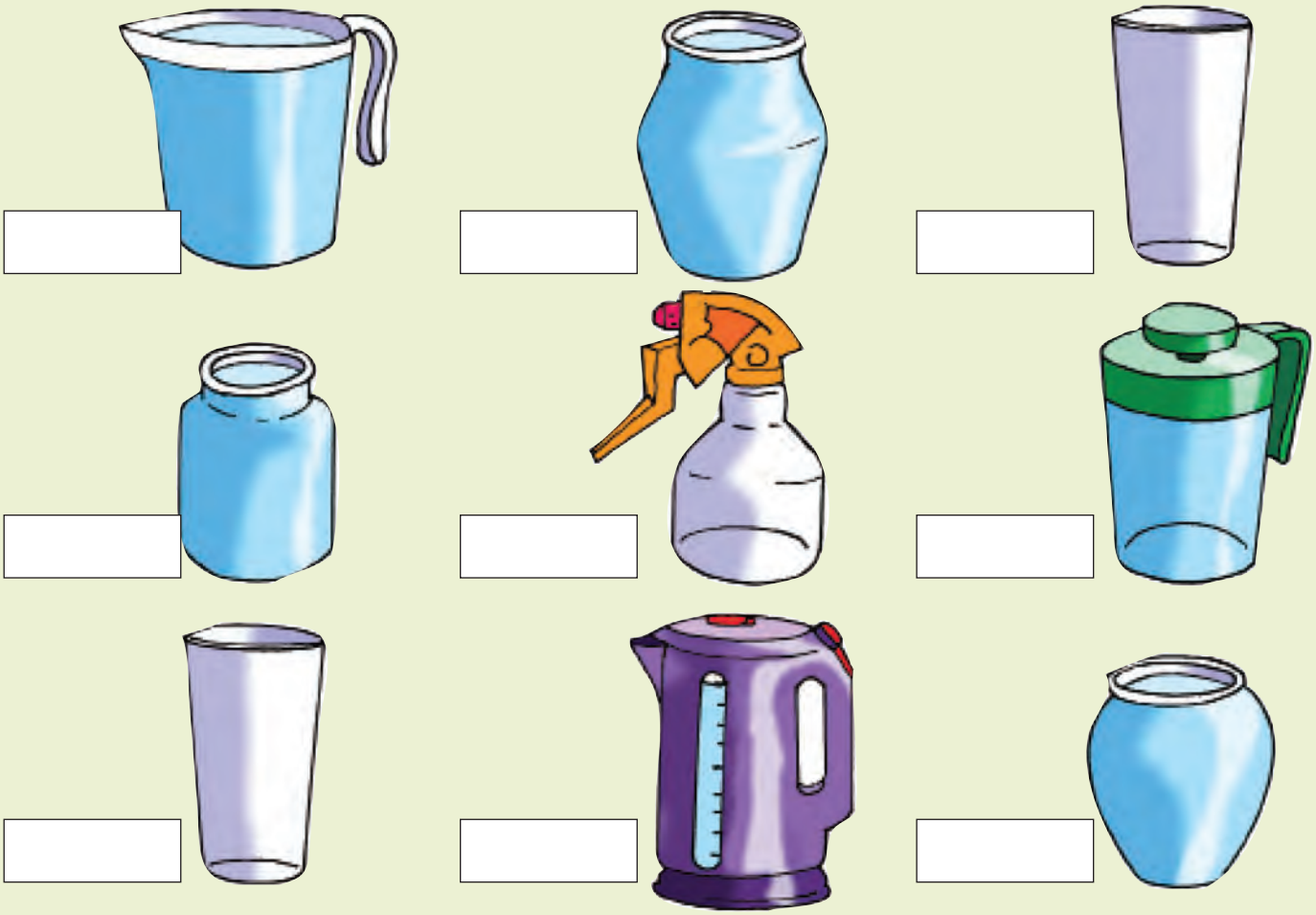



Fakela umbala nokuba kukoluphi ulwelo olukwezi zikhongozeli..

Akukho nto

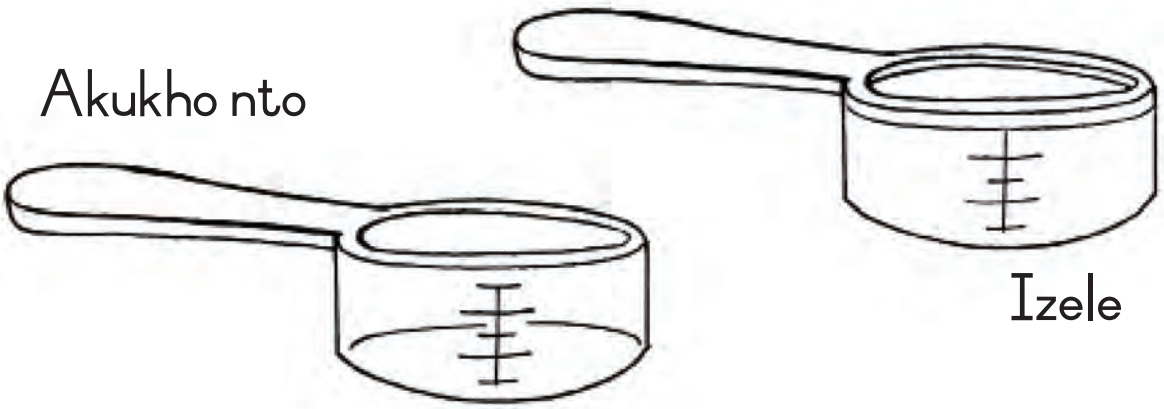

Izele

Zizobele ezakho izikhongozeli uze uf akele umbala kwinto engaphakathi.

Akukho nto	Izele
Akukho nto	Izele

Teacher:
Sign:
Date:

11 12 13 14 15 16 17 18 19 20

Umhla:

Ukuphinda-phinda: x 3

Zingaphi iilekese eziphezu kwetafile nganye?



Gqibezela oku kulandelayo:

amaqela ama-2 esi-3 | 3 + 3 = | 3 × 2 =

amaqela ama-3 esi-3 | 3 + 3 + 3 = | 3 × 3 =

amaqela ama-4 esi-3 | 3 + 3 + 3 + 3 = | 3 × 4 =

amaqela ama-6 esi-3 | 3 + 3 + 3 + 3 + 3 + 3 = | 3 × 6 =

amaqela asi-7 esi-3 | 3 + 3 + 3 + 3 + 3 + 3 + 3 = | 3 × 7 =

Zoba oku kulandelayo.

amaqela ama-3 esi-3

amaqela ama-4 esi-3

amaqela ama-5 esi-3



Zoba oku kulandelayo.

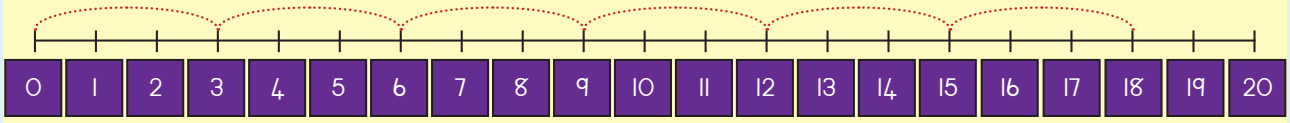

3, 6, 9, 12, ___ , ___

3 + 3 + 3 + 3 + 3 + 3 = ☐

6 × 3 = ☐

Ukuzoba



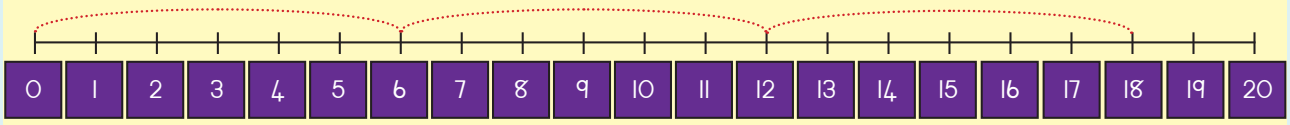

6, ___ , ___

6 + ☐ + ☐ = ☐

3 × ☐ = ☐

Ukuzoba

Imbiza yokupheka inemilenze emithathu. Zinemilenze emingaphi iimbiza zokupheka ezisi-7.

☐



3 6 9 12 15 18

21 24 27 30 33

Teacher:

Sign:

Date:

Umhla: _____

Iipatheni: Ngantathu

1 Masibale ngezithathu.





2 Zoba okanye uncamathisele imifanekiso yezinto ezime ngantathu.

3 Sikuqalele ipatheni. Yigqibezele.

1	2	3	4	5	6	7	8	9	10
11	12	13	14	15	16	17	18	19	20
21	22	23	24	25	26	27	28	29	30
31	32	33	34	35	36	37	38	39	40
41	42	43	44	45	46	47	48	49	50
51	52	53	54	55	56	57	58	59	60
61	62	63	64	65	66	67	68	69	70
71	72	73	74	75	76	77	78	79	80
81	82	83	84	85	86	87	88	89	90
91	92	93	94	95	96	97	98	99	100



Sebenzisa imigca-manani ukubhala ipatheni.

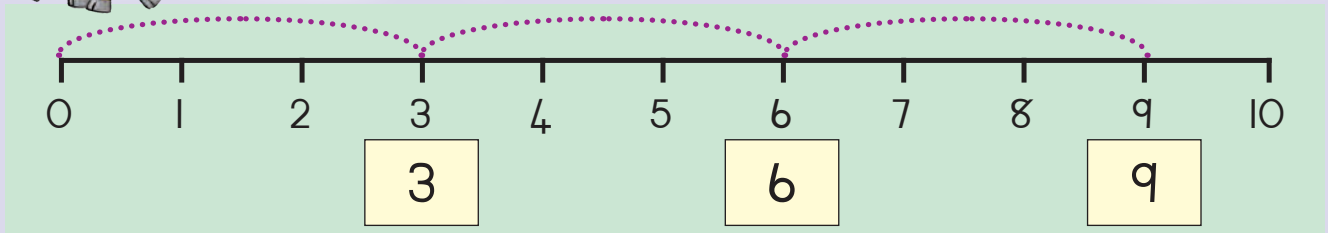

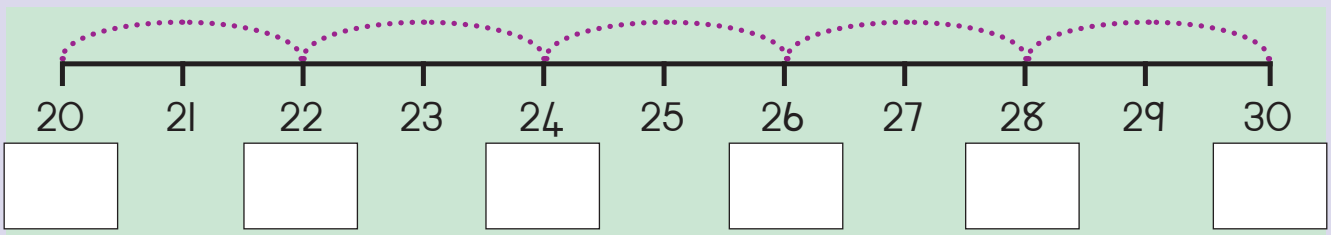

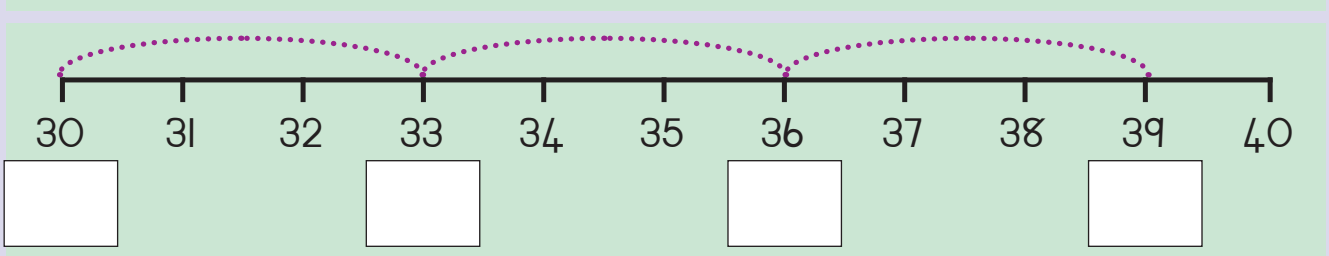

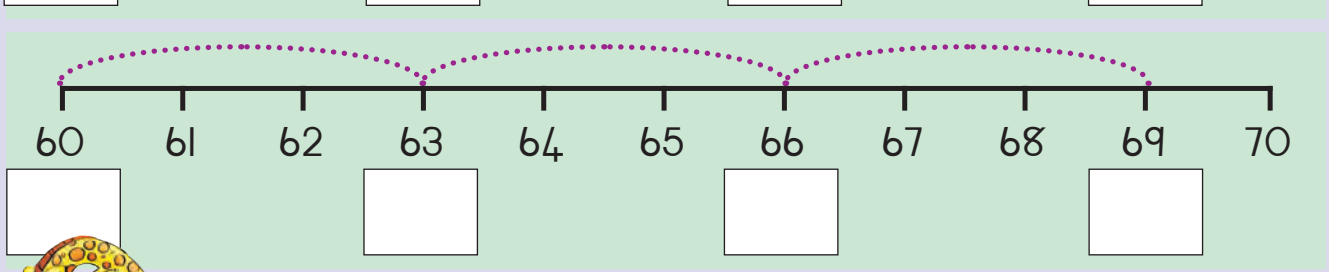



Gqibezela oku kulandelayo.

3, 6, 9, __, __, __	1, 4, 7, __, __, __	99, 96, 93, __, __, __
36, 39, 42, __, __, __	22, 25, 28, __, __, __	66, 63, 60, __, __, __
12, 15, 18, __, __, __	15, 12, 9, __, __, __	40, 37, 34, __, __, __



Kukho itrayisekile ezi-10 ekiritshi. Mangaphi amavili akhoyo?

Teacher:
Sign:
Date:



Umhla: _____

Ukuphinda-phinda: x 4

Zingaphi iilekese eziphezu kwetafile nganye?



Gqibezela oku kulandelayo:

amaqela ama-3 ezi-4 | 4 + 4 + 4 = | 3 × 4 = ☐

amaqela ama-2 ezi-4 | 4 + 4 = | 2 × 4 = ☐

amaqela ama-4 ezi-4 | 4 + 4 + 4 + 4 = | 4 × 4 = ☐

amaqela ama-6 ezi-4 | 4 + 4 + 4 + 4 + 4 + 4 = | 6 × 4 = ☐

amaqela asi-7 ezi-4 | 4 + 4 + 4 + 4 + 4 + 4 + 4 = | 7 × 4 = ☐

Zoba umfanekiso.

amaqela ama-3 ezi-4

amaqela ama-4 ezi-4

amaqela ama-5 ezi-4



Zoba umfanekiso.

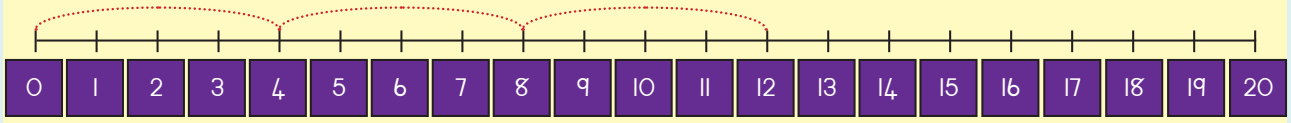

4, 8, ___

4 + 4 + 4 = ☐

4 × 3 = ☐

Ukuzoba



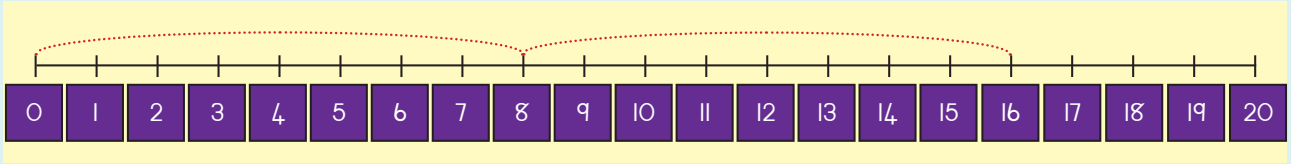

8, ___

8 + ☐ = ☐

8 × ☐ = ☐

Ukuzoba



Ihashe linemilenze emi-4.
Anemilenze emingaphi amahashe ama-3? ☐



4 8 12 16 20 24
28 32 36 40

Teacher:
Sign:
Date:



11 12 13 14 15 16 17 18 19 20



Umhla: _____

Iipatheni zamanani: Izine

1 Masibale ngezine.





2 Zoba okanye uncamathisele umfanekiso wezinto ezime ngane.

3 Sikuqalele ipatheni. Yigqibezele.

1	2	3	4	5	6	7	8	9	10
11	12	13	14	15	16	17	18	19	20
21	22	23	24	25	26	27	28	29	30
31	32	33	34	35	36	37	38	39	40
41	42	43	44	45	46	47	48	49	50
51	52	53	54	55	56	57	58	59	60
61	62	63	64	65	66	67	68	69	70
71	72	73	74	75	76	77	78	79	80
81	82	83	84	85	86	87	88	89	90
91	92	93	94	95	96	97	98	99	100





Sebenzisa imigca-manani ukubhala ipatheni.

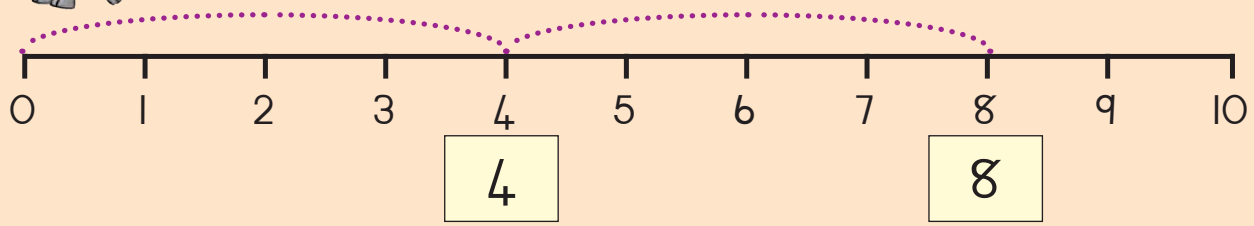

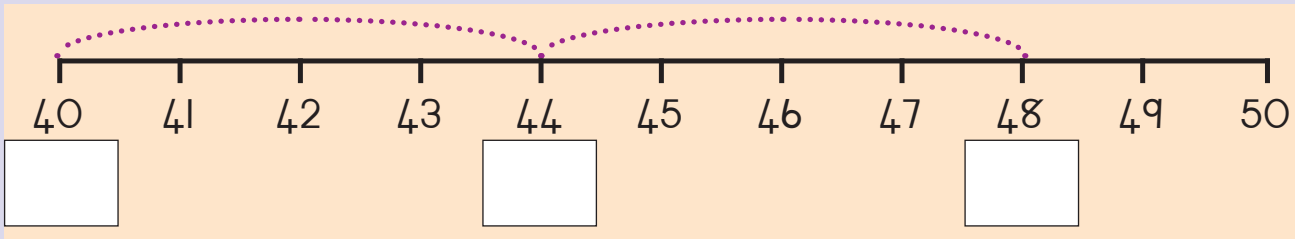

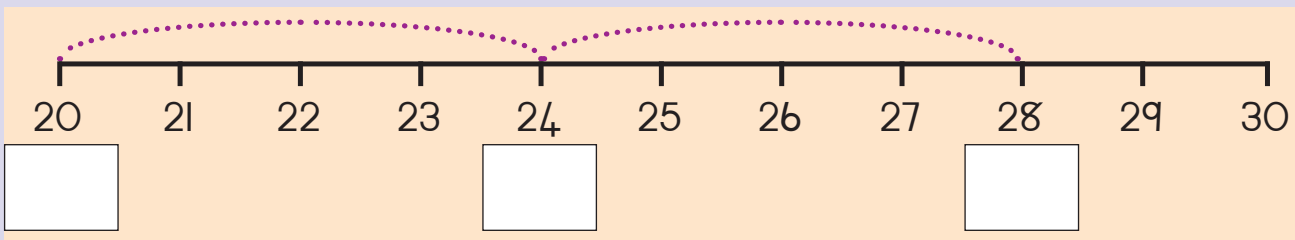

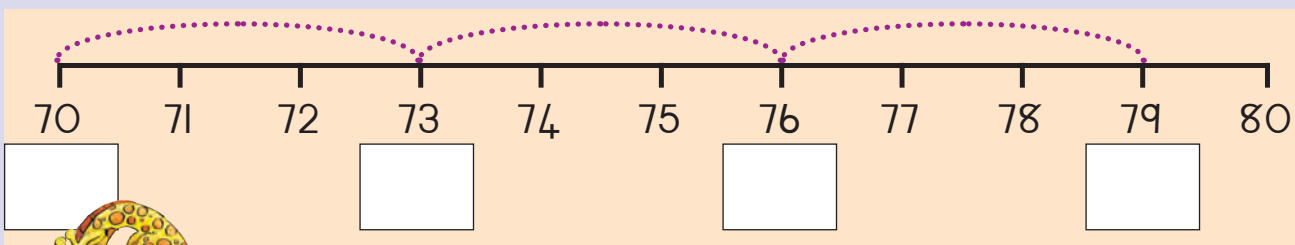



Sebenzisa imigca-manani ukubhala ipatheni.

4, 8, 12, __ , __ , __	1, 5, 9, __ , __ , __	48, 44, 40, __ , __ , __
28, 32, 36, __ , __ , __	42, 46, 50, __ , __ , __	60, 56, 52, __ , __ , __
12, 16, 20, __ , __ , __	20, 16, 12, __ , __ , __	70, 66, 62, __ , __ , __



Kukho iibhisikithi ezine epakethini. Ndithengise iipakethe ezili-9.
Zingaphi iibhisikithi endizithengisileyo?

Teacher:
Sign:
Date:



Umhla:

Ukuphinda-phinda amabali

Zenzele ibali elilelakho, usebenzise amagama afana nala: amehlo, imilenze, izandla, iinyawo, izilwanyana, abantu. Yongeza inani kuzo zonke ezo zinto.



Ikati inamehlo amabini. Mangaphi amehlo eekati ezi-4?



Faka umbala emehlweni eekati

Bonisa impendulo yakho ngesixhobo sokubala.

Bonisa impendulo yakho ngomgca-manani.

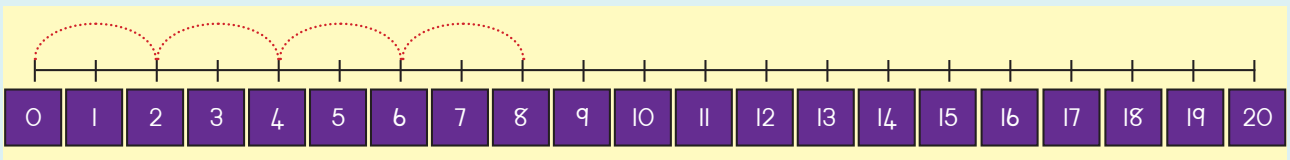

□ + □ + □ + □ = □

□ × □ = □



Itrayisikile inamavili ama-3. Mangaphi amavili eetrayisikile ezi-5?



Faka umbala kumavili etrayisikili.

Bonisa impendulo yakho ngesixhobo sokubala.

Bonisa impendulo yakho ngomgca-manani.

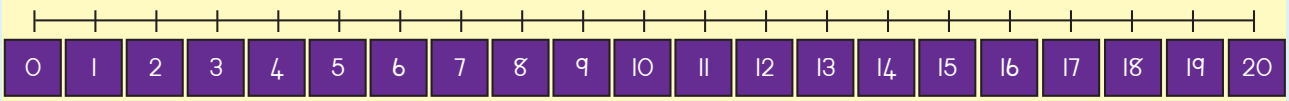

+ = × =

Inja inemilenze emi-4. Mingaphi imilenze yezinja ezi-4?



Faka umbala kwimilenze yenja.

Bonisa impendulo yakho ngesixhobo sokubala.

Bonisa impendulo yakho ngomgca-manani.

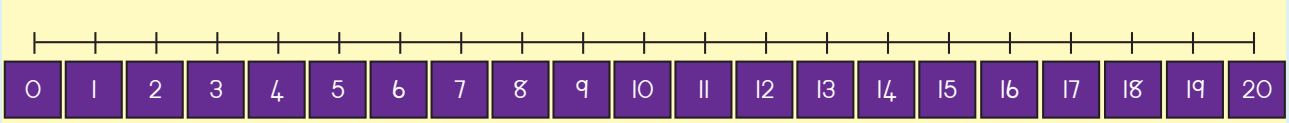

+ = × =

Teacher:
Sign:
Date:



Umhla:

Iiyure

1 Ncokola ngewotshi.



Usiba olufutshane lubonisa iiyure.
Apha lubonisa iiyure ezisi-7.

Usiba lwewotshi luyajikeleza, luthi jikelele jikelele ngqu.
Usiba lwewotshi luthi jikelele jikelele ngqu lusixelela ixesha.

2 Usiba olufutshane lusibonisa ntoni?



iyure e- ☐ iiyure ezi- ☐ iiyure ezi- ☐ iiyure ezi- ☐



iiyure ezi- ☐ iiyure ezi- ☐ iiyure ezi- ☐ iiyure ezi- ☐



iiyure ezi- ☐ iiyure ezi- ☐ iiyure ezi- ☐ iiyure ezi- ☐

Zoba usiba olufutshane.

iiyure ezi-4



iyure e-1



iiyure ezili-11



iiyure ezisi-7



iiyure ezili-9



iiyure ezili-10



iiyure ezi-2



iiyure ezi-5



iiyure ezi-3



iiyure ezi-6



iiyure ezisi-8



iiyure ezili-12



Yintoni enokuthatha iyure? Fakela umbala kwimpendulo echanekileyo.



Ukwenza umsebenzi wesikolo ekhaya



Ukulala



Ukubhrasha amazinyo

Teacher:
Sign:
Date:

Umhla: _____

Iipatheni zamanani: Izihlanu

1 Masibale ngezihlanu.





2 Zoba okanye uncamathisele umfanekiso wezinto ezime ngantlanu.

3 Sikuqalele ipatheni. Yigqibezele.

1	2	3	4	5	6	7	8	9	10
11	12	13	14	15	16	17	18	19	20
21	22	23	24	25	26	27	28	29	30
31	32	33	34	35	36	37	38	39	40
41	42	43	44	45	46	47	48	49	50
51	52	53	54	55	56	57	58	59	60
61	62	63	64	65	66	67	68	69	70
71	72	73	74	75	76	77	78	79	80
81	82	83	84	85	86	87	88	89	90
91	92	93	94	95	96	97	98	99	100



Sebenzisa imigca-manani ukubhala ipatheni.

0 1 2 3 4 5 6 7 8 9 10

0 5 10

40 41 42 43 44 45 46 47 48 49 50

21 22 23 24 25 26 27 28 29 30 31

70 71 72 73 74 75 76 77 78 79 80

Gqibezela oku kulandelayo:

5, 10, 15, __ , __ , __	1, 6, 11, __ , __ , __	50, 45, 40, __ , __ , __
20, 25, 30, __ , __ , __	23, 28, 33, __ , __ , __	60, 55, 50, __ , __ , __
30, 35, 40, __ , __ , __	25, 20, 15, __ , __ , __	54, 49, 44, __ , __ , __

5 10 15 20 25 30 35 40 45 50

Teacher:
Sign:
Date:

11 12 13 14 15 16 17 18 19 20

Umhla:

Imizuzu

Yintoni le migcana mifutshane imnyama isebusweni bewotshi?





Cinga ngayo yonke into onokuyenza ngomzuzu nje omnye.

Fakela imizuzu.



Bhala amanani akwizikwere ezibomvu apha.



Zoba izinto onokuzenza ...

Ngomzuzu omnye	Ngemizuzu emi-5
Ngemizuzu engama-30	Ngemizuzu engama-60

Teacher:
Sign:
Date:

11 12 13 14 15 16 17 18 19 20

57b



Umhla:

Imizuzu engaphezulu

Ncokola ngewotshi.



Usiba olude lusibonisa imizuzu.
Apha lusibonisa imizuzu eli-10.

Usiba lwewotshi luyajikeleza, luthi jikelele jikelele ngqu.
Usiba lwewotshi luthi jikelele jikelele ngqu lusixelela ixesha.



Lusibonisa ntoni usiba olude?



imizuzu eli - ☐



imizuzu engama - ☐



imizuzu engama - ☐



imizuzu engama - ☐



imizuzu engama - ☐



imizuzu e - ☐

1 2 3 4 5 6 7 8 9 10





Zoba usiba olude.

imizuzu engama-55



imizuzu engama-35



imizuzu engama-60



imizuzu eli-10



imizuzu engama-45



imizuzu eli-12





Yintoni enokuthatha umzuzu omnye? Fakela umbala kwimpendulo echanekileyo.



Ukutsibatsiba



Ukudlala



Ukutya



Teacher:

Sign:

Date:



11 12 13 14 15 16 17 18 19 20



Umhla: _____

Ukwenza amaqela nokwahlulelana

1 Zingaphi iibhloko ezikwisangqa ngasinye? Zabele abantwana zonke.



2 Zingaphi iibhloko ezikwisangqa ngasinye? Bhala inani lazo zonke kwisangqa esibhulowu.

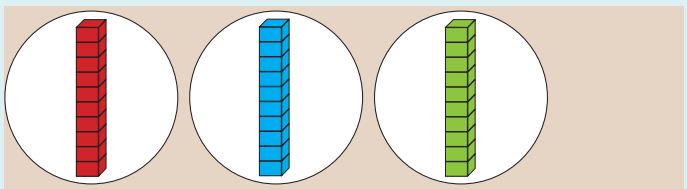

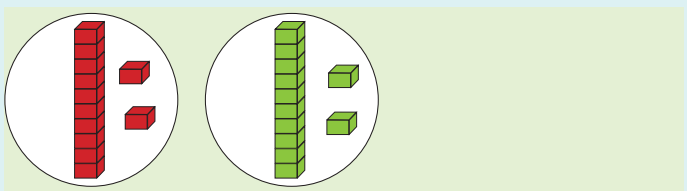

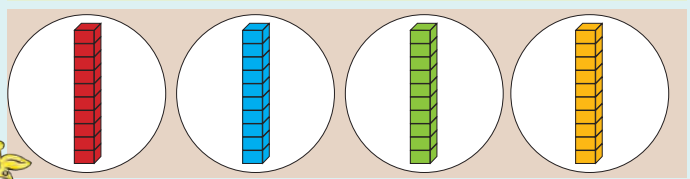

_____ × _____ = _____

_____ × _____ = _____

_____ × _____ = _____

3 Zahlulele kwisangqa iibhloko.

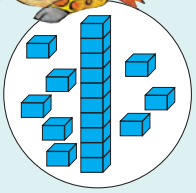

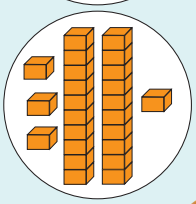

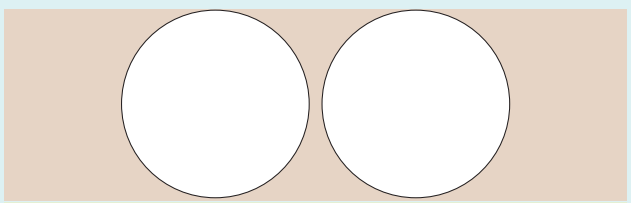



_____ ÷ _____ = _____

_____ ÷ _____ = _____



Zoba oku kulandelayo. Uze ubalele iqela ngalinye.

Amaqela ama-3 ezi-2

+ Isibalo sokudibanisa:

× Isibalo sokuphindaphinda:

Amaqela ama-2 ama-25

+ Isibalo sokudibanisa:

× Isibalo sokuphindaphinda:

Yahlula izixhobo zokubala ezili-12 ka-4

— Isibalo sokuthabatha:

÷ Isibalo sokwahlula:

Yahlula izixhobo zokubala ezingama-36 ka-3

— Isibalo sokuthabatha:

÷ Isibalo sokwahlula-hlula:

Bala.

Amaqela ama-2 kasi-7 _____ Amaqela ama-3 kasi-8 _____

Amaqela ama-4 ka-5 _____ Amaqela ama-2 ka-15 _____

Yahlula i-18 ngesi-2 _____ Yahlula ama-24 ngesi-3 _____

Yahlula ama-35 ngesi-5 _____ Yahlula ama-50 nge-10 _____

Bekukho amaqela ama-6 ezi-5 ethekweni lam.
Bangaphi abantwana ababesethekweni lam?

Teacher:
Sign:
Date:

11 12 13 14 15 16 17 18 19 20

Umhla: _____

Ukwenza amaqela nokwahlulelana

1 Zingaphi iibhloko ezikwisangqa ngasinye? Zabele abantwana zonke.



2 Zingaphi izixhobo zokubala ezikwisangqa ngasinye? Bhala inani lazo zonke kwisangqa esibhulowu.

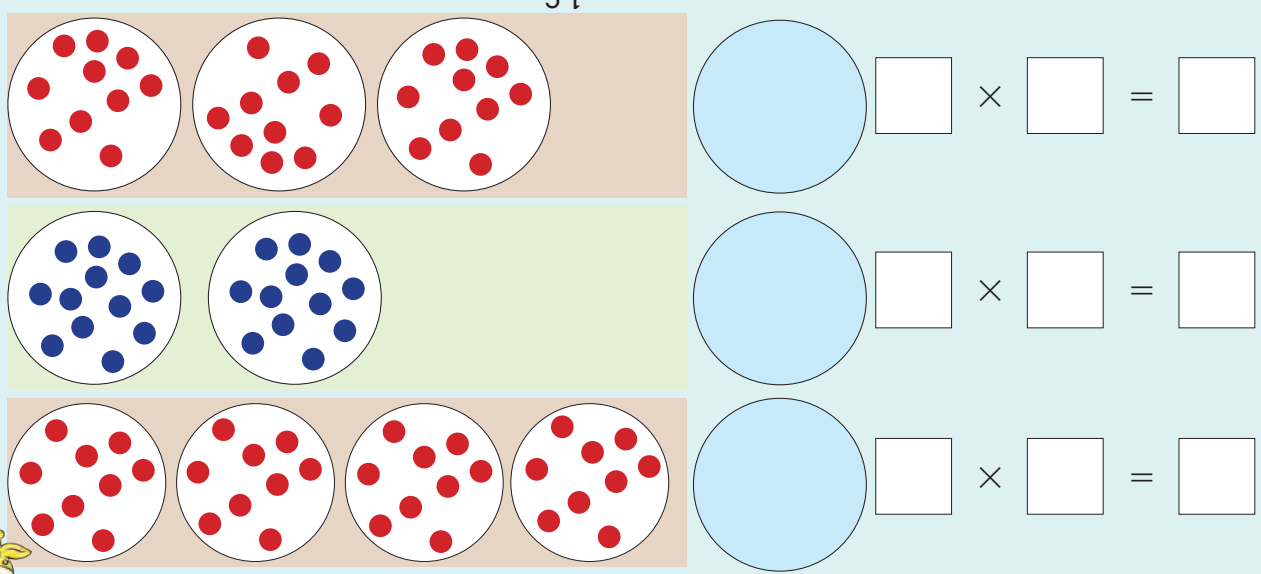

3 Yahlulahlula izixhobo zokubala eziphakathi kwezangqa.

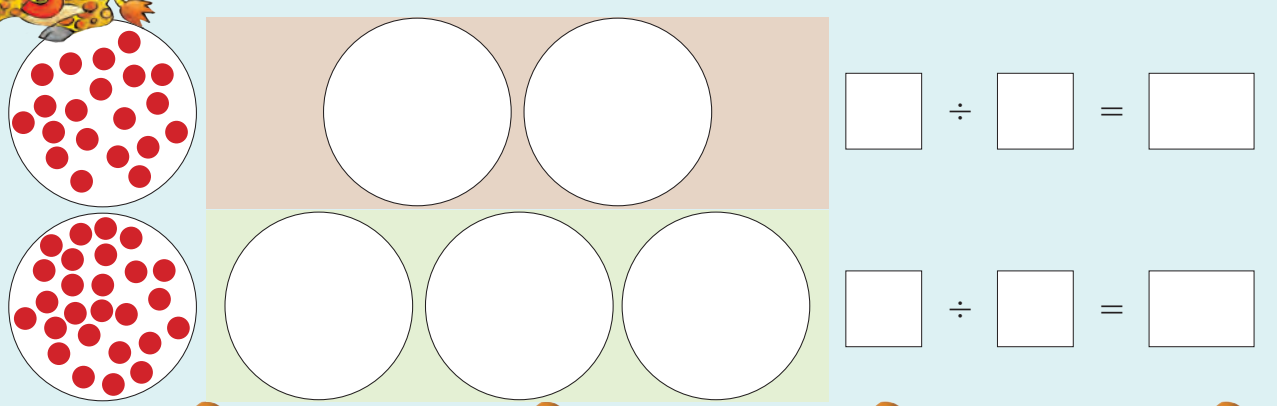



Zoba oku kulandelayo. Uze ubalele iqela ngalinye.

Amaqela ama-3 e-12

+ Isibalo sokudibanisa:

× Isibalo sokuphinda-phinda:

Amaqela ama-5 e-10

+ Isibalo sokudibanisa:

× Isibalo sokuphinda-phinda:

Yahlula izixhobo ezingama-24 ka-4.

− Isibalo sokuthabatha:.

÷ Isibalo sokwahlula-hlula:

Yahlula izixhobo zokubala ezingama-25 ka-5.

− Isibalo sokuthabatha:.

÷ Isibalo sokwahlula-hlula:



Bala.

Amaqela ama-2 e-11 _____

Amaqela ama-3 e-10 _____

Amaqela ama-4 esi-4 _____

Amaqela ama-2 ama-25 _____

Yahlula ama-20 ka-2 _____

Yahlula ama-27 ka-3 _____

Yahlula ama-50 ka-5 _____

Yahlula ama-28 ka-2 _____



ukuphinda phinda kabini

Teacher:
Sign:
Date:



11 12 13 14 15 16 17 18 19 20

Umhla: _____

Ukwenza amaqela nokwahlulelana

1 Zingaphi izixhobo zokubala eziphakathi kwisangqa ngasinye?
Zahlulele abantwana ababini.



2 Zingaphi izixhobo zokubala eziphakathi kwesangqa ngasinye?

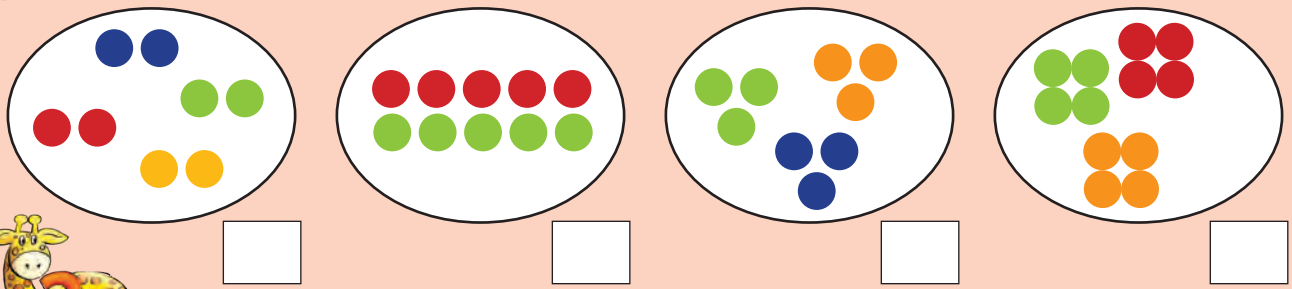

3 Sika iimilo eziphuma kuMsiko-4 uze uzincamathisele kwibhloko echanekileyo.
Bala iimilo.











Yahlulela abantwana iimilo. Sebenzisa iimilo eziphuma kuMsiko-4.

oonxantathu





izikwere











Yahlulela abantwana iziqhamo. Zizobe.





onamaorenji





onama-apile













UJohn noBelinda bahlulelene ngokulinganayo iilekese ezili-12. Ufumene iilekese ezingaphi emnye?

Teacher:

Sign:

Date:



11 12 13 14 15 16 17 18 19 20

Umhla:

Ukwenza amaqela nokwahlulelana

1 Mangaphi amaso aphakathi kwisangqa ngasinye? Wahlule phakathi kwabantwana.



2 Mangaphi amaso akwisangqa ngasinye?

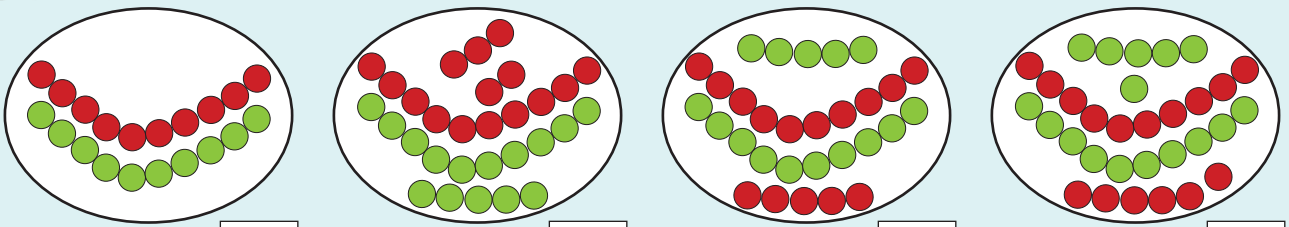

3 Sika amaso aphuma kuMsiko-4 uze uwancamathisele apha.
Bala amaso.

Amaso abomvu	Amaso abhulowu
Amaso atyheli	Amaso aluhlaza

1 2 3 4 5 6 7 8 9 10



Zoba inani lamaso elilingana umntwana ngamnye.






Nika umntwana ngamnye inani lamaso ngokulinganayo. Zoba.

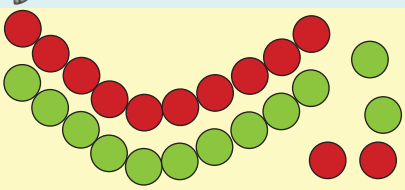
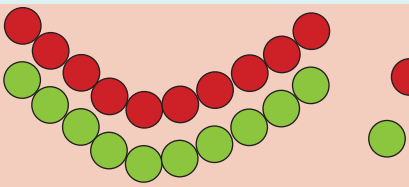







UBusi noZaheda bahlulelene ngokulinganayo iipenisile ezingama-32.
Ufumene iipenisile ezingaphi emnye?

Teacher:
Sign:
Date:

Umhla:

Iziqingatha: 1–20

Kwenzeke ntoni kuma-apile?





Yahlula iziqhamo ezingasekhohlo kwibhasikithi engasekunene. Zoba.





Zoba umgca ukubonakalisa isiqingatha.

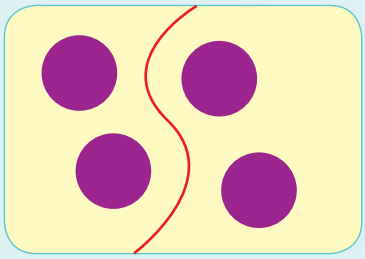

Isiqingatha sesi-4 sisi-

2



Isiqingatha sesi-6 sisi-



Isiqingatha sesi-8 sisi-



Isiqingatha sesi-2 ngu-

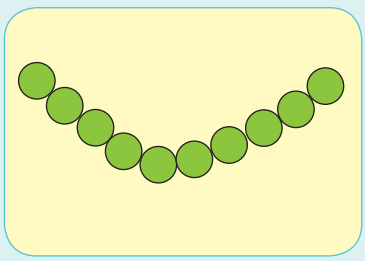

Isiqingatha se-10 sisi-

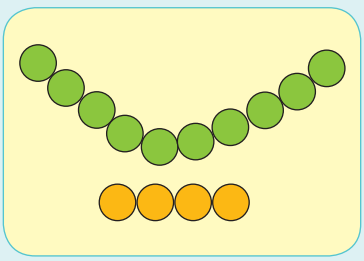

Isiqingatha se-14 sisi-

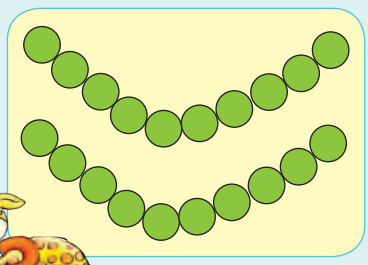

Isiqingatha sama-20 li-

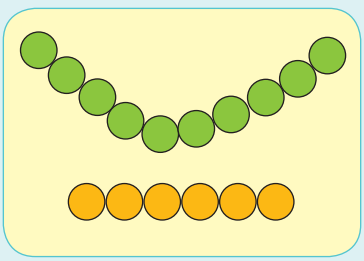

Isiqingatha se-16 sisi-



Nika isiqingatha sepleyiti nganye yokutya.





Teacher:

Sign:

Date:



11 12 13 14 15 16 17 18 19 20

Umhla:

Ukwahlula-hlula 20–50



Kwenzeke ntoni kumaso?







Yohlula amaso asekhohlo kwibhasikiti esekunene. Yizobe.

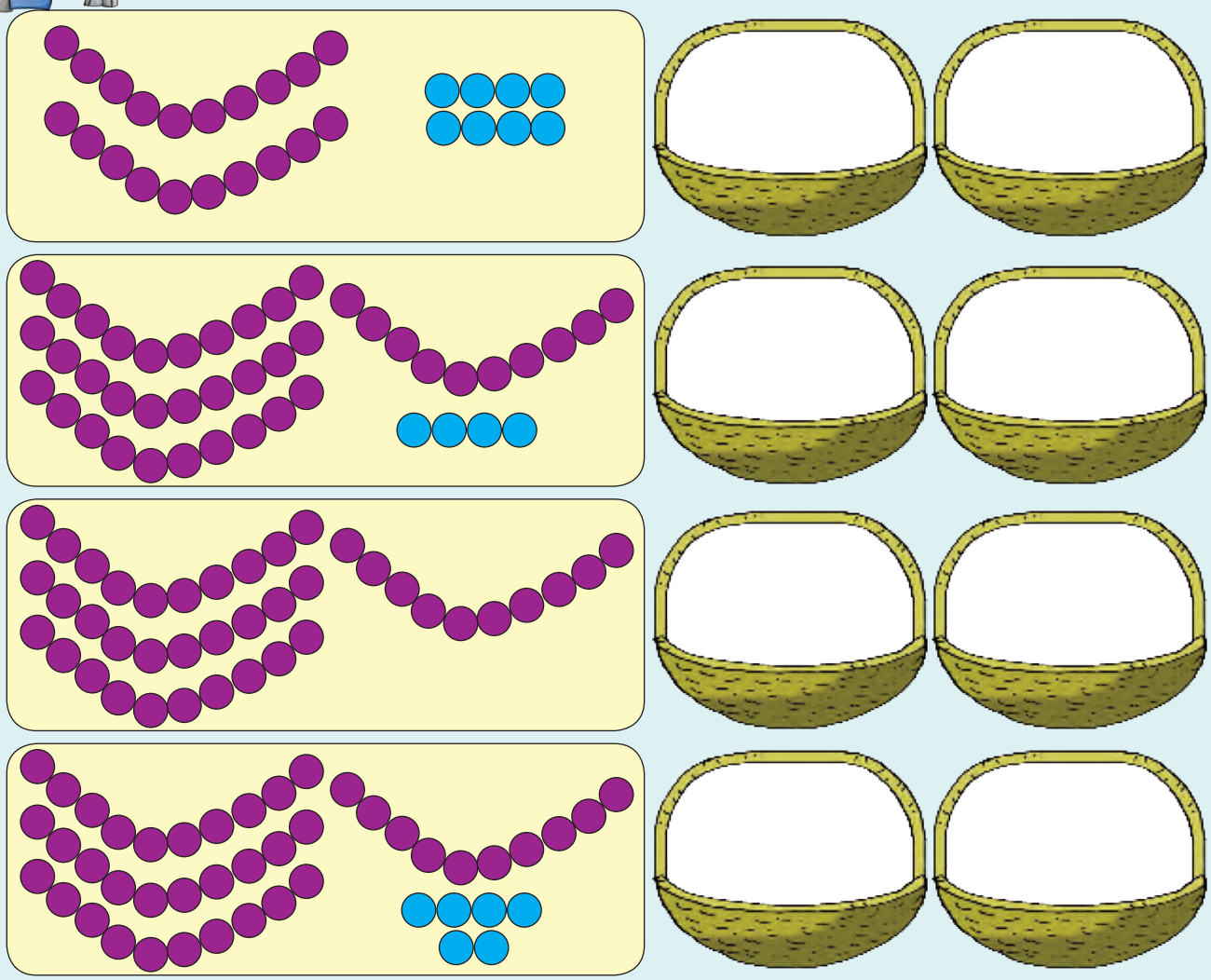



Yenza isiqingatha sibe ngumbala owahlukileyo.

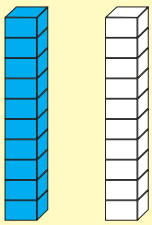

Isiqingatha sama-20 li- 10

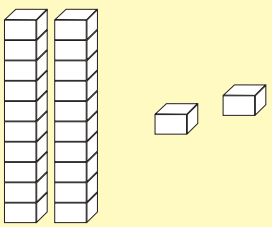

Isiqingatha sama-22 li- ☐

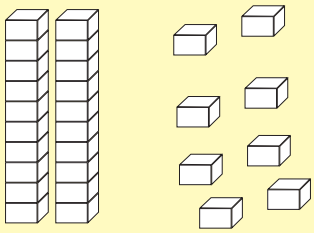

Isiqingatha sama-28 li- ☐

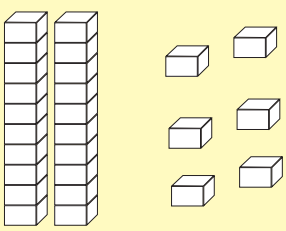

Isiqingatha sama-26 li- ☐



Isiqingatha sama-40 ngama- ☐

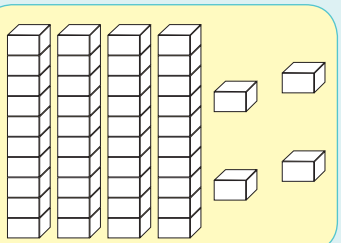

Isiqingatha sama-44 ngama- ☐

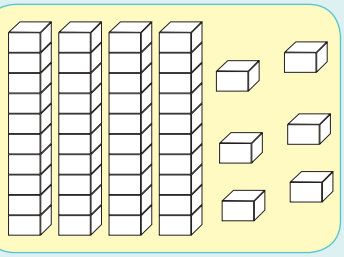

Isiqingatha sama-46 ngama- ☐

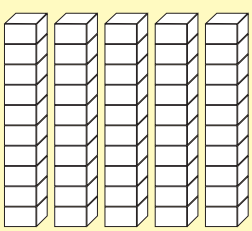

Isiqingatha sama-50 ngama- ☐

Faka umbala kwicala ngalinye lesiqingatha sedayagramu.

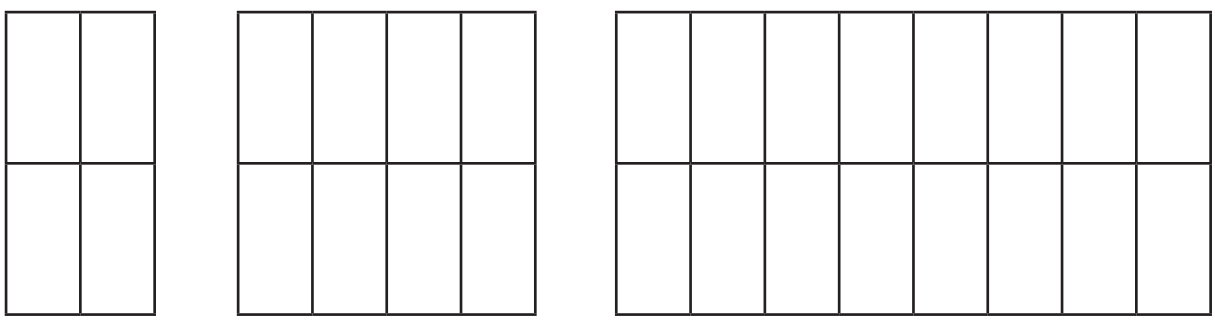

Teacher:
Sign:
Date:

Umhla: _____

Idatha



Hlela iziqhamo. Yenza owakho umzobo ubonise oku. Bhala inani ebhokisini.

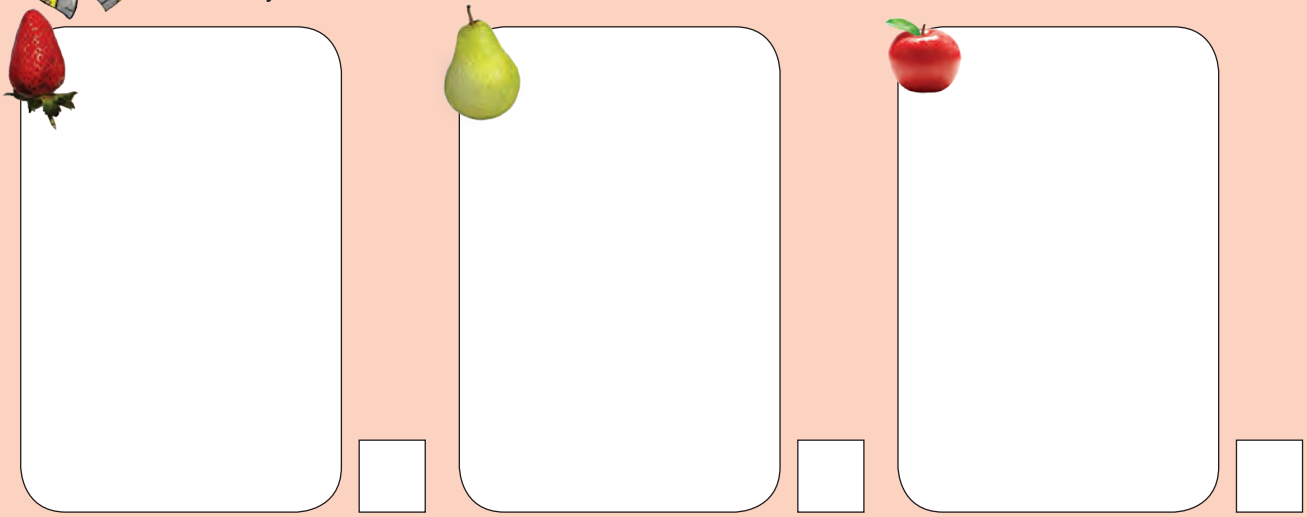

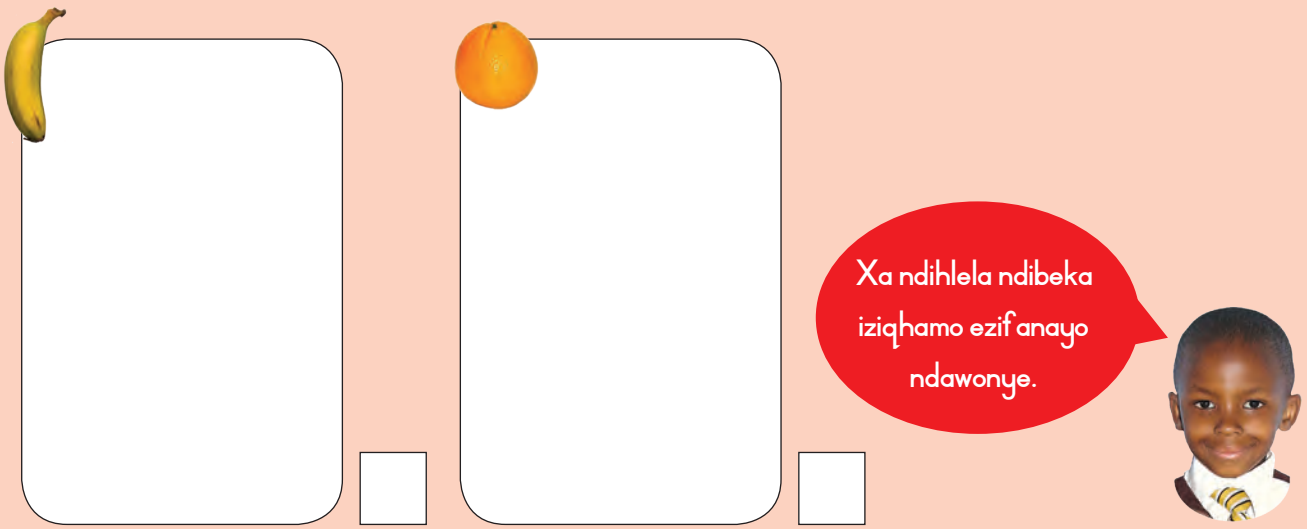

Xa ndihlela ndibeka iziqhamo ezifanayo ndawonye.

Umsiko 1

Iphepha lokusebenzela le-10 nelama-40



Iphepha lokusebenzela le-13

ngentseni	ngorhatya	emva kwemini
ubusuku/ ebusuku	ebusuku kakhulu	kusasa nasemva kwemini

Umsiko 2

Iphepha lokusebenzela lama-22

Iziganeko zeMbali nezibalulekileyo

Usuku lwamalungelo oluntu	Usuku loxolelwaniso	Usuku lwabasebenzi
Usuku lolutsa	Usuku lwezamafa	Usuku loomema lwesize
	Usuku lwenkululeko	

Imiqondiso yezeenkolo



eyamaBahai | eyamaJuda | eyamaBhudda | eyamaSilamsi | eyamaKrestu | eyesiNtu | yamaHindu

Cut-out 3

Worksheets 25 and 26



R50	R50	R50	R50	R50
R10	R10	R10	R10	R10
R20	R20	R20	R20	R20
R100	R100	R100	R100	R100
R50	R50	R50	R50	R50
R10	R10	R10	R10	R10
R20	R20	R20	R20	R20
R100	R100	R100	R100	R100

Cut-out 4

Worksheet 27



Worksheet 60





Worksheet 61

