

UKkz. Angie Motshekga.
nguNqgonqgotjhe
wezeFundo-Sisekelo



UNom Enver Surty.
nguSekela kaNqgonqgotjhe
wezeFundo-Sisekelo

Iincwadi lezi zenzelwe abentwana beSewula Afrika ngaphasi koburholi bakaNqgonqgotjhe wezeFundo-Sisekelo, uMma u-Angie Motshekga.kanye neSekela lakNqgonqgotjhe wezeFundo-Sisekelo, uNom. Enver Surty.

Iincwadi zokuSebenzela zakwaRainbow ziyingcenye yeendlela ezinengi zomNyango wezeFundo-Sisekelo wokungenelela onqophe ukuthuthukisa ukusebenza ngcono kwabafundi beSewula Afrika kumagreyidi wokuthoma asithandathu. Njengamanye wamaHlelo womBuso aphuma phambili, iphrojekthi le isekelwe ngeemali ezibuya esiKhwameni seeMali seLizweloke. Lokhu kusize umNyango ukukhupha iincwadi zokusebenzela lezi ngawo woke amalimi asemthethweni ngaphandle kweendleko. Siyathemba kobana nizokufunyana iincwadi zokusebenzela lezi zilisizo khulu ekufundiseni kwenu kwangamalanga kanye nokuqinisekisa kobana abafundi benu bayayiqeda ikharikhyulamu.

Sitjheje khudlwana ukuhlahla abotitjhere komunye nomunye umsebenzi ngokusebenzisa iinthombe ezitjengisako bona ngikuphi umfundi amele akwenze.

Siyathemba kobana abentwana bazokuthabela ukusebenzisa iincwadi lezi njengombana bakhula bebafunda nje, begodu wena titjhere uzokwabelana nabo ithabo lokufunda. Sinifisela ipumelelo ekusebenziseni iincwadi lezi.



Rainbow WORKBOOKS

MATHEMATICS IN ISINDEBELE
GRADE 2 – BOOK 1
TERMS 1 & 2
ISBN 978-1-920458-97-3

THIS BOOK MAY NOT BE SOLD.

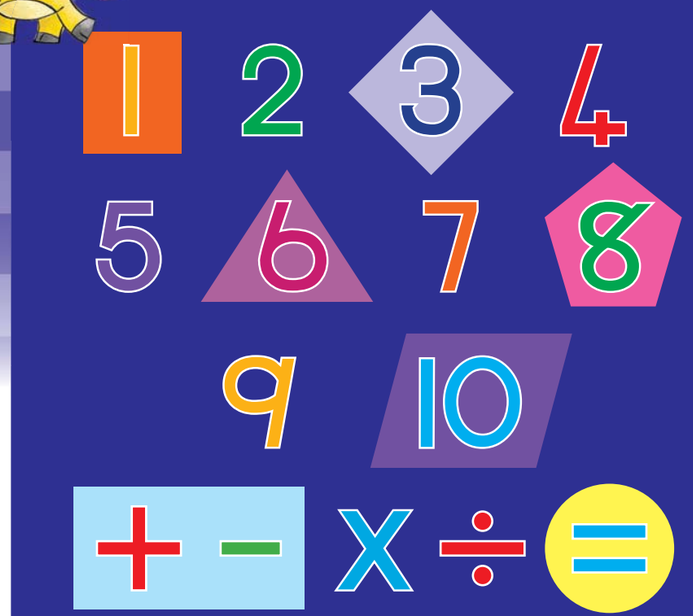

IZIBALO NGESINDEBELE – IGreyidi 2 Incwadi 1

ISBN 978-1-920458-97-3



IGreyidi 2

Ibizo:

Itlasi:

basic education
Department:
Basic Education
REPUBLIC OF SOUTH AFRICA

IZIBALO NGESINDEBELE

Incwadi 1

Ithemu 1 & 2

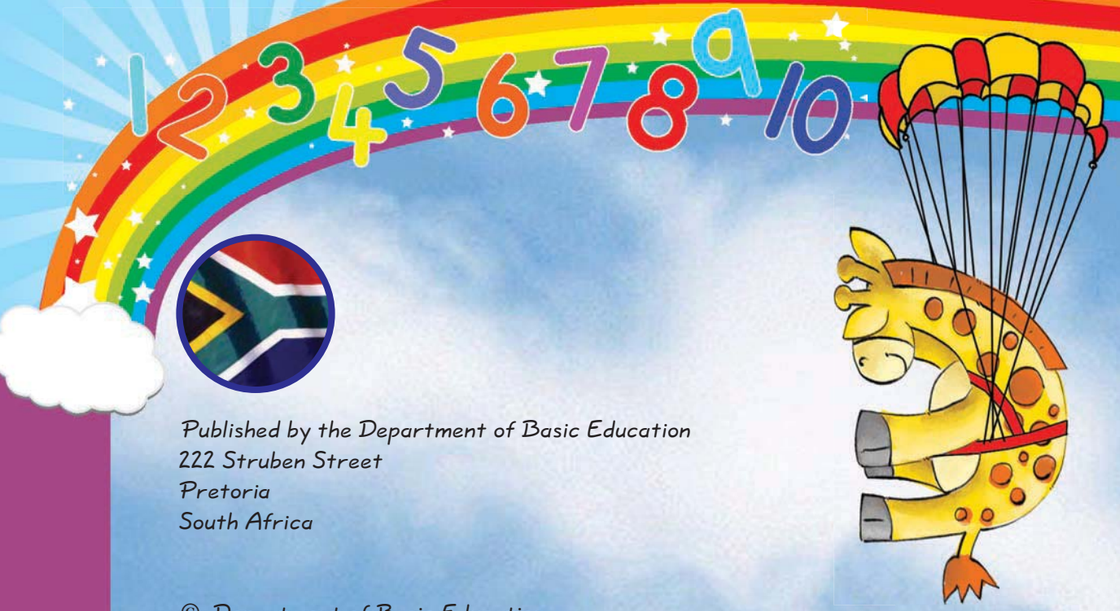



1 – 100

1	2	3	4	5	6	7	8	9	10
11	12	13	14	15	16	17	18	19	20
21	22	23	24	25	26	27	28	29	30
31	32	33	34	35	36	37	38	39	40
41	42	43	44	45	46	47	48	49	50
51	52	53	54	55	56	57	58	59	60
61	62	63	64	65	66	67	68	69	70
71	72	73	74	75	76	77	78	79	80
81	82	83	84	85	86	87	88	89	90
91	92	93	94	95	96	97	98	99	100

Published by the Department of Basic Education
222 Struben Street
Pretoria
South Africa

© Department of Basic Education
Third edition 2013

ISBN 978-1-920458-97-3

The Department of Basic Education has made every effort to trace copyright holders but if any have been inadvertently overlooked, the Department will be pleased to make the necessary arrangements at the first opportunity.

This book may not be sold.



basic education
Department:
Basic Education
REPUBLIC OF SOUTH AFRICA

1 2 3 4 5 6 7 8 9 10 11 12 13 14 15 16 17 18 19 20 21 22 23 24 25 26 27 28 29 30 31 32 33 34 35 36 37 38 39

IGreyidi 2

Rainbow WORKBOOKS

Izibalo

ngesiNDEBELE

Incwadi le ngeyaka-:



ISINDEBELE

Incwadi 1

Ilanga:

Mina nomdeni wakwethu

Ngineminyaka ebunane.



Inomboro yendlu yekhaya li-12.



Ngingomncani emndenini wakwethu.



Nginabodade ababili.



Ubaba uneminyaka ema-32 ubudala.



Zalisa iimpendulo emibuzweni elandelako mayelana nawe kanye nomndeni wakwenu.





Gwala isithombe somndeni wakwenu.



1 2 3 4 5 6 7 8 9



11 12 13 14 15 16 17 18 19 20



Teacher:

Sign:

Date:



Ilanga:

Ukubala



Bala uzalise iinkhala ezinganalitho.



Iye		2
amacaphazi	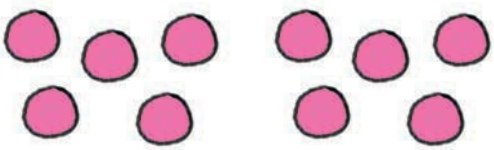	
amapetjhi		



Iye		
amacaphazi		
amapetjhi		







lye

amacaphazi

amapetjhi



lye

amacaphazi

amapetjhi



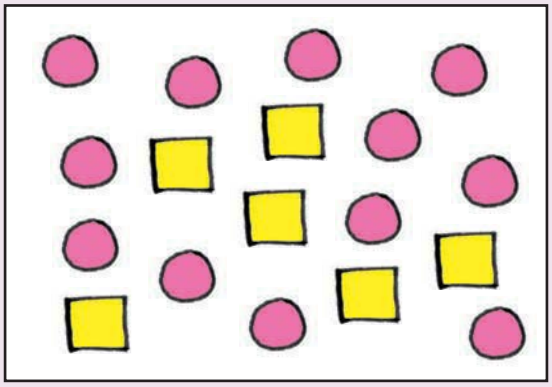

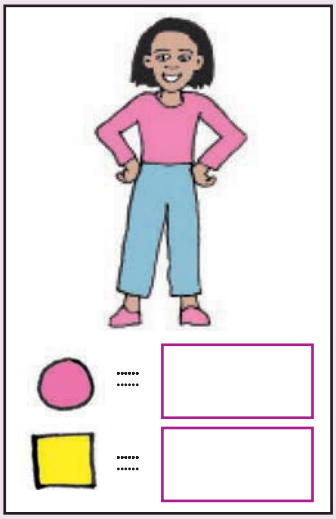



Teacher:

Sign:

Date:

11 12 13 14 15 16 17 18 19 20

Ilanga: _____

Iinomboro

Funda amatshwayo weenomboro namagama ebhodini.

I	73	59	lithoba	litjhumi nakunye
66	35		litjhumi nakune	
				litjhumi nekhomba
42	97		kune	sithandathu
24	32		litjhumi nethoba	litjhumi

Tlola isibalo somncamo ngebhlogweni.

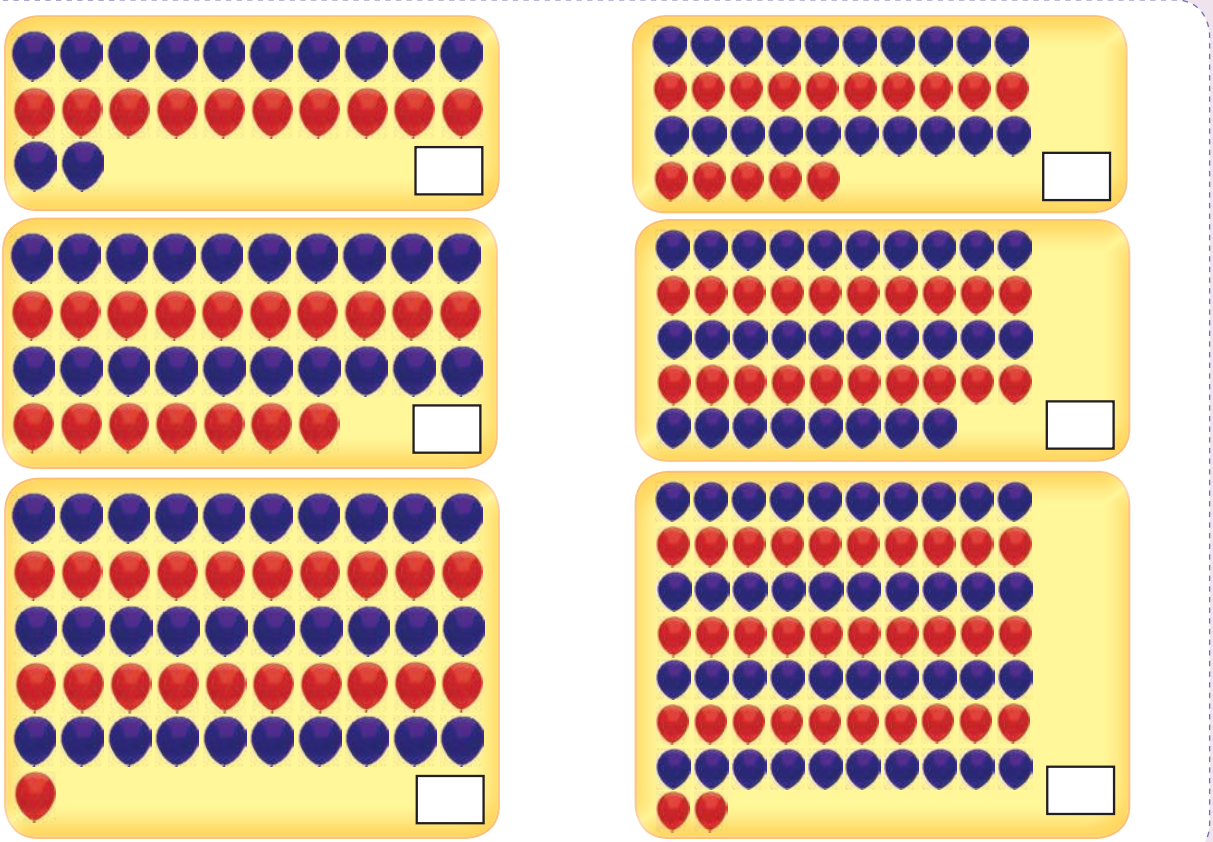





Tlola iinomboro ezilandelako ngamagama.

6		12	
4		17	
8		14	
1		22	
2		18	
5		11	
0		20	
10		15	
3		13	
9		16	



37 38 39 40 41 42 43 44

89 90 91 92 93 94 95 96 97

Teacher:

Sign:

Date:

11 12 13 14 15 16 17 18 19 20



Ilanga:

Iinomboro





Gwala u △ ngeenomboro ezilinganako no – ○ ngeenomboro ezingalinganiko.

linganako	I	2	3	4	5	6	7	8	9	10
ngalinganiko	II	I2	I3	I4	I5	I6	I7	I8	I9	20



Isibalo sezindlu.







Bala imibala yomibili yomncamo.



Tlola inomboro eyipendulo.

10	2	=	12
10	3	=	
10	5	=	
10	8	=	
10	9	=	

Singayitlola njengokuthi:

10 + 2 = 12

□ + □ = □

□ + □ = □

□ + □ = □

□ + □ = □



Ithini ipendulo.

10 + 1 = □	10 + 9 = □	10 + 6 = □
10 + 8 = □	10 + 2 = □	10 + 3 = □
10 + 5 = □	10 + 4 = □	10 + 7 = □



1 3 5 7 9 11 13 15 17 19

2 4 6 8 10 12 14 16 18 20

Teacher:

Sign:

Date:



11 12 13 14 15 16 17 18 19 20

Ilanga:

Ukuhlanganisa nokukhupha





Hlanganisa begodu ukhuphe.



9 + 8 = 17



18 − 8 = ☐



☐ + ☐ = ☐



☐ + ☐ = ☐



☐ + ☐ = ☐



Bala.

6 + 5 = ☐	8 + 9 = ☐	11 + 3 = ☐	12 − 5 = ☐
8 + 7 = ☐	3 + 8 = ☐	9 − 5 = ☐	16 − 9 = ☐
6 + 4 = ☐	8 + 4 = ☐	8 − 4 = ☐	6 − 4 = ☐





Hlanganisa.

	+		+		+		=	
2	+	2	+	2	+	2	=	8

	+		+		+		=	
	+		+		+		=	
	+		+		+		=	
	+		+		+		=	
	+		+		+		=	
	+		+		+		=	
	+		+		+		=	
	+		+		+		=	
	+		+		+		=	
	+		+		+		=	
	+						=	
	+						=	

Bala.

2 + 2 + 2 =	
4 + 4 =	
5 + 5 + 5 =	

1 + 1 + 1 + 1 + 1 + 1 =	
3 + 3 + 3 + 3 =	
5 + 5 =	

2 + 2 + 2 + 2 =	
4 + 4 + 4 + 4 =	
1 + 1 + 1 =	

2 + 2 + 2 + 2 + 2 + 2

Teacher:

Sign:

Date:



Ilanga:

Ukwabelana kanye nemali



Yabelana ngeenthelo ezingenzasi.

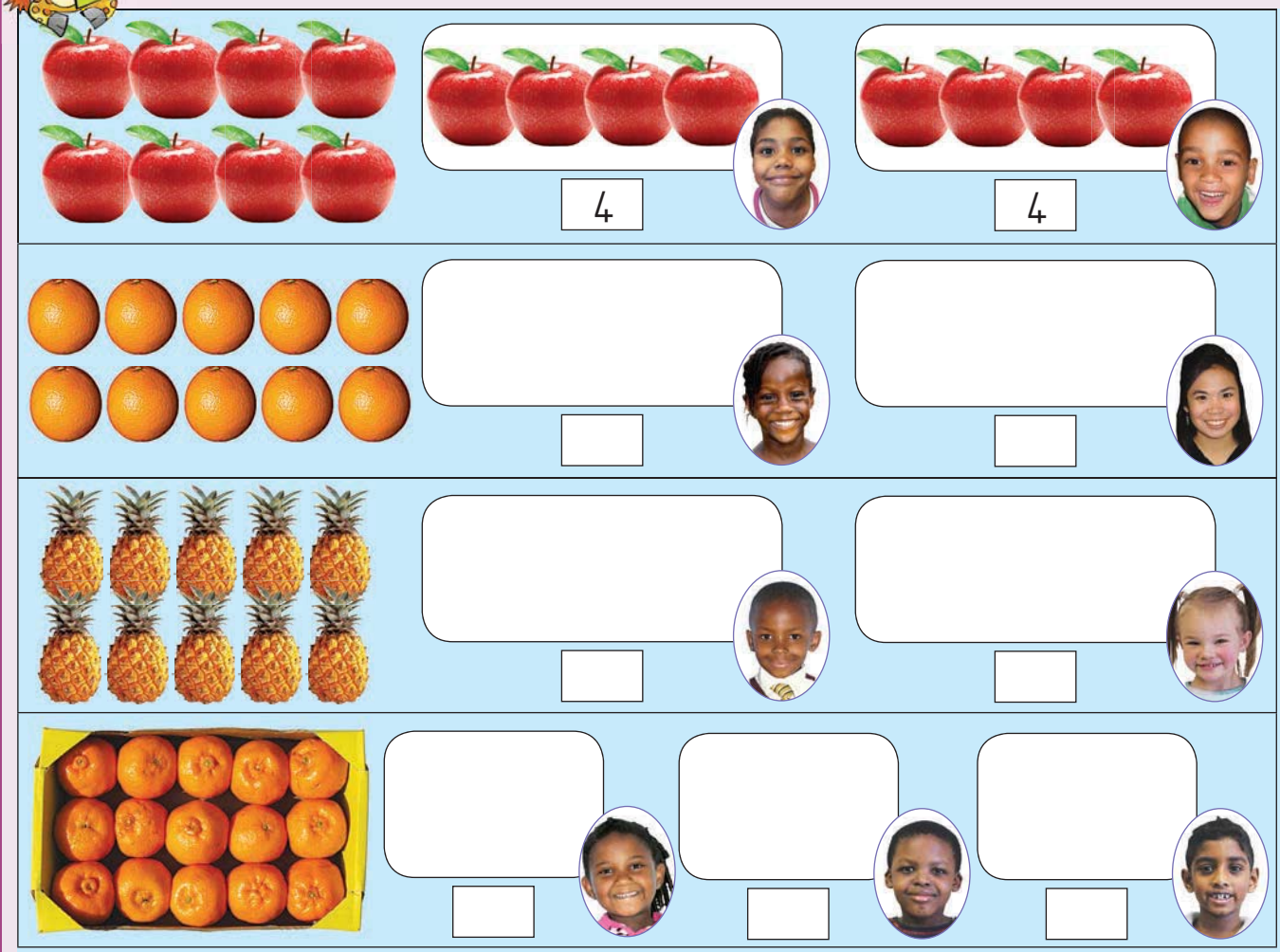









Qedelela.



isende yi-1					





Faka umbala esiliveni efaneleko leyo eyenza isibalo esifanako.



10c	10c	5c	2c	1c	2c



5c	2c	2c	1c	2c	2c



R2	R2	R1	R1	R1



= R5 R2 R1 R5 R1 R2



= R2 R2 R5 R5 R2 R1 R5



R1 1c R5 5c R10



Teacher:
Sign:
Date:



Ilanga:

Amaphetheni

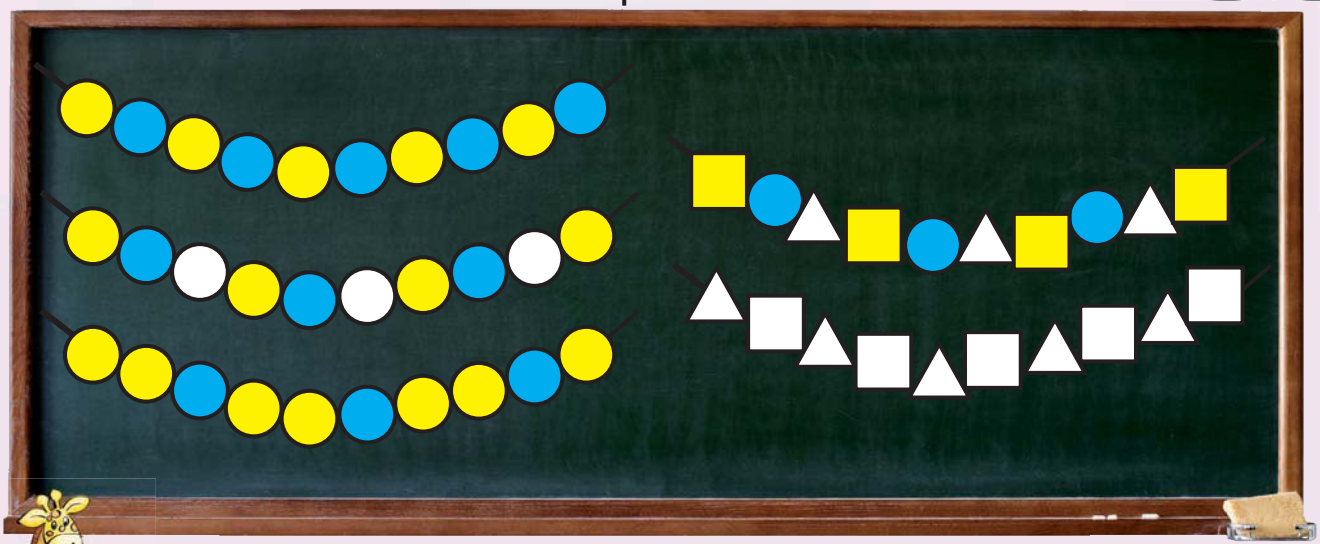



Kopulula amaphetheni asebhodini.





Ngezelela amaphetheni.



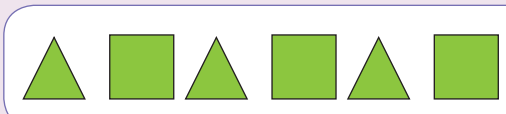











Faka umbala emncanyeni nawulokhu ubala ngakubili.



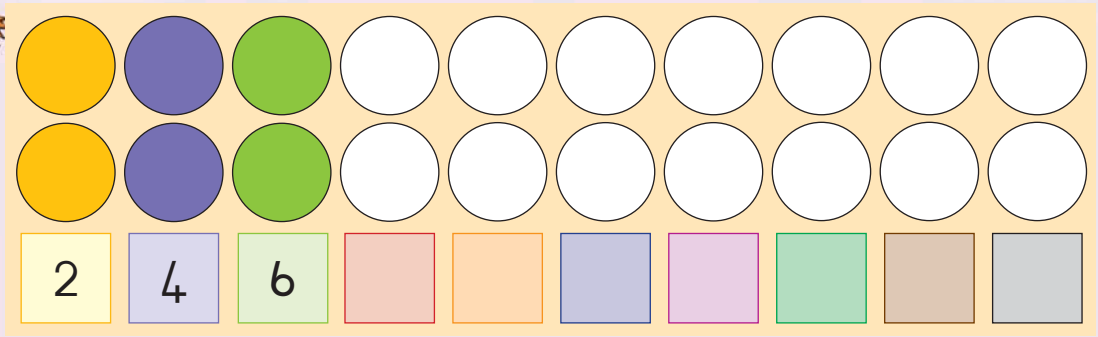



Faka umbala ngemathuthumbeni nawulokhu ubala ngakuhlanu.

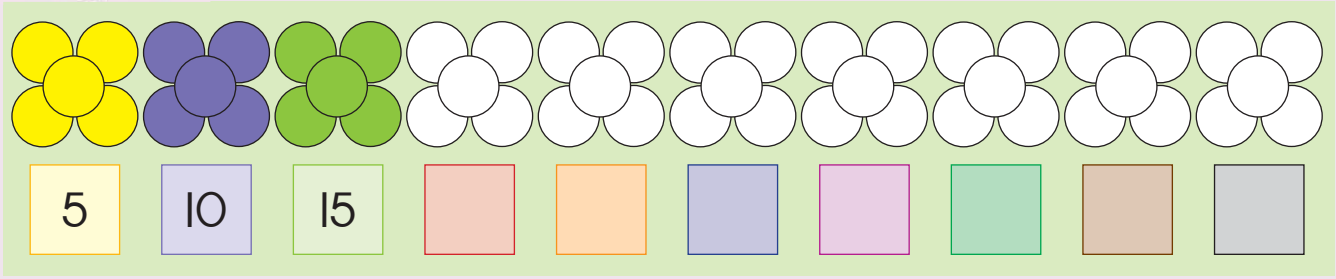



Faka umbala ngemncanyeni nawulokhu ubala ngamatjhumi.

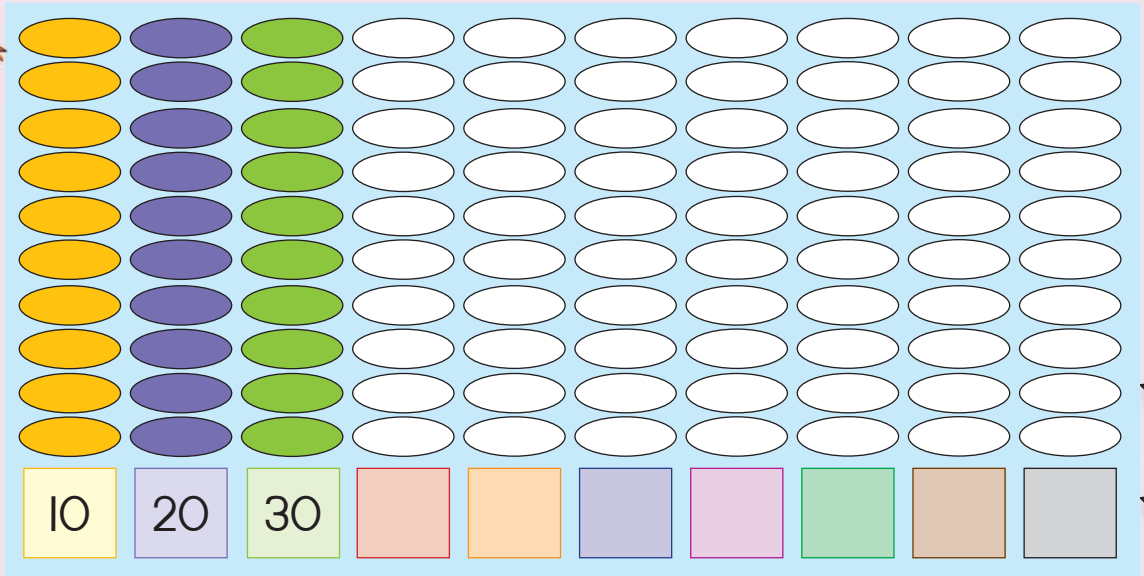



OLIAOLIAOLIA

Teacher:
Sign:
Date:



11 12 13 14 15 16 17 18 19 20

Ilanga:

Amabumbeko



Faka aboncazine umbala ohlaza kwesibhakabhaka, amasekeli abe bomvu aboncantathu babe sarulani.

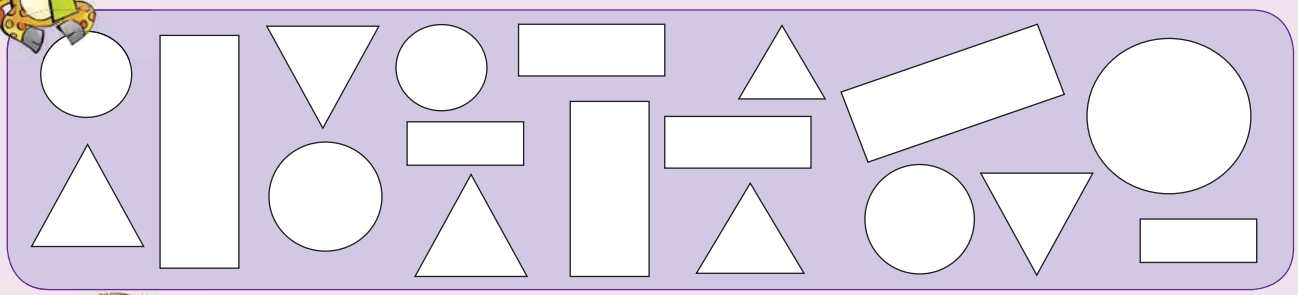

Faka amasekeli woke umbala obomvu, aboncazine babehlaza kwesibhakabhaka begodu aboncantatnu abancani babe sarulani.

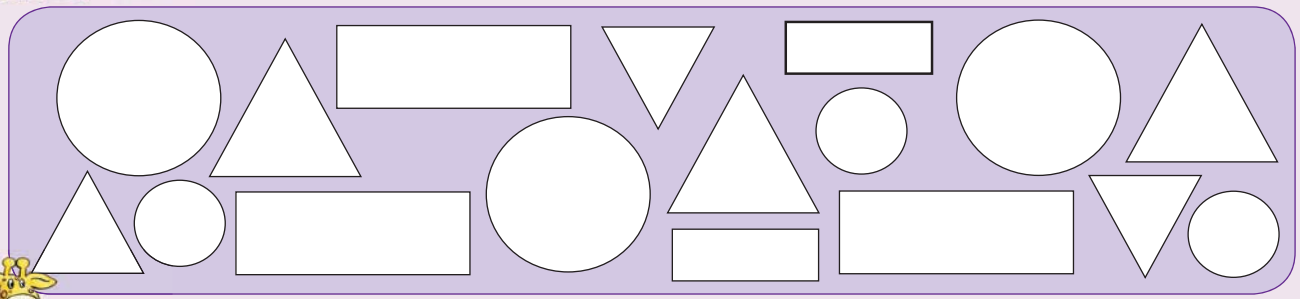

Faka umbala ependulweni efaneleko.



nqophileko | isekeli



nqophileko | isekeli



nqophileko | isekeli





Gwala amanye amahlangothi wamaviyaviyani.







Teacher:

Sign:

Date:



11 12 13 14 15 16 17 18 19 20



9

Ilanga:

Iimbholo namabhoksi





Ndulungela amabhoksi ngokuhlaza kwesibhakabhaka begodu iimbholo ngokubomvu.



Faka umbala ependulweni efaneleko.



Ibhoksi | liyatjhelela | liyagedeka



Ibholo | iyatjhelela | iyagedeka

1 2 3 4 5 6 7 8 9 10



Faka umbala ependulweni efaneleko.



umphetho oyindulungu

umphetho obunqopha



umphetho oyindulungu

umphetho obunqopha



umphetho oyindulungu

umphetho obunqopha



umphetho oyindulungu

umphetho obunqopha



umphetho oyindulungu

umphetho obunqopha



umphetho oyindulungu

umphetho obunqopha



umphetho oyindulungu

umphetho obunqopha



umphetho oyindulungu

umphetho obunqopha

Itjho nakhibe ibholo ingemva, ngaphambili, ngeqadi kwebhoksi namkha phezu kwebhoksi.



ngemva | ngaphambili

ngeqadi kwe | phezulu



| ngaphambili

| phezulu



| ngaphambili

ngeqadi kwe | phezulu

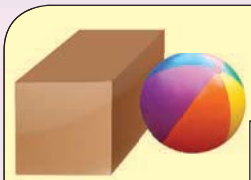

ngemva | ngaphambili

ngeqadi kwe | phezulu



ibholo ibhoksi

Teacher:

Sign:

Date:

Ilanga:

Ubude





Ingabe ngisiphi isitimela esifitjhazana namkha esidenyana?





fitjhazana | denyana



fitjhazana | denyana



Ingabe ngimuphi umakhiwo omudenyana namkha omfitjhazana?

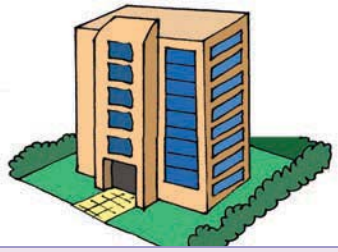

phezudlwana

phasanyana



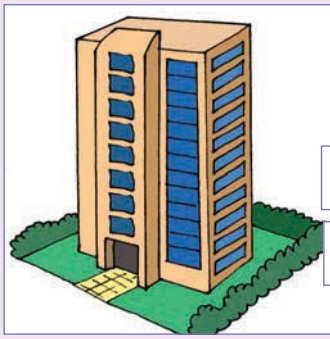

phezudlwana

phasanyana





Ingabe ngimuphi umuntu omfitjhazana namkha omudenyana?



omfitjhazana

omudenyana

omfitjhazana

omudenyana



Sebenzisa isandla esisikweko. Ingabe uncazine lo uzizandla ezingaki ubude?
Sebenzisa inyawo elisikweko. Ingabe uncazine uziinyawo ezingaki ubude?



Kwanjesi meda ukuphakama kwakancazine ngesandla nangeenyawo.





II

Ilanga:

Ubungako



Itjho nakhibe into ibudisana namkha iludlana.



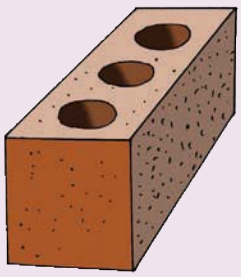

ibudisana	iludlana	ibudisana	iludlana

Ndulungela into ebudisana.









1 2 3 4 5 6 7 8 9 10



Ingabe into le ibudisana namkha iludlana kunekhilogremu linye?



ibudisi | ilula



idisi | ilula



ibudisi | ilula



libudisi | lilula

ubudisi ubulula

Teacher:
Sign:
Date:

11 12 13 14 15 16 17 18 19 20



Ilanga:

Umthamo





Faka umbala ependulweni efaneleko.



zeleko	nganalitho	ihafu



zeleko	nganalitho	ihafu



zeleko	nganalitho	ihafu



zeleko	nganalitho	ihafu

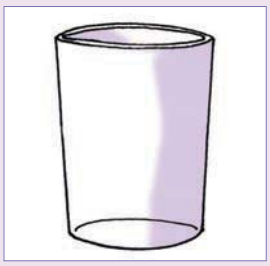

zeleko	nganalitho	ihafu



zeleko	nganalitho	ihafu







Isimedo sinye sizalisa ukufika esimeregweni sejege.
Ingabe ijege le izokuzaliswa ziimedo ezingaki?





Ingabe ziimedo ezingaki ezithelwe ngeenjegeni lezi?



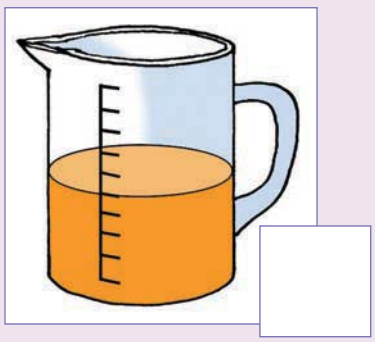





Ijege engesinceleni inejuzi e-lilitha li-1. Ingabe ngiyiphi ijege enejuzi elinganako begodu ngiyiphi enejuzi encani.



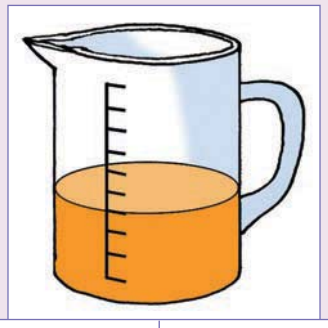

linganako | ncani



linganako | ncani



zeleko nganalitho

Teacher:
Sign:
Date:



11 12 13 14 15 16 17 18 19 20

Ilanga: _____

Isikhathi

1

Iya kokusikwako ko-1. Sika amagama bese uwanamathisela ngaphasi kweenthombe.



2

Qedelela imitjho.

Ngi_____ ekuseni ngamasa.

Ngi_____ ekuseni.

Ngi_____ ngemva kwedina.

Ngi_____ ngamalanga.

Ngi_____ ngemva kwesikhathi ngamalanga.



Izolo | Namhlanjesi | Kusasa









Phendula imibuzo.

Ingabe umntwana wenzani namhlanjesi? _____

Ingabe wenzeni izolo? _____

Ingabe umntwana uzokwenzani kusasa? _____



Gwala isithombe sakho.

Izolo	Namhlanjesi	Kusasa



Izolo





Teacher:
Sign:
Date:



11 12 13 14 15 16 17 18 19 20

Ilanga: _____

Ikhalenda lamalanga wamabeletho



Landela ukwelamana kweenyanga.

UTjhirhweni
uSipho
uMaryke
uAnnie

UMhlolanja
uJeffrey
uSimon

UNtaka
uSam
uJuan

USihlabantangana
uBetty
uLiezel

UMrhayili
uLettie
uRicco
uGeorge

UMgwengweni
uMpho

UVelabahlinze
uPalesa
uLisa
uKayla

URhoboyi
uMbali
uBrenda
uMary

UKhukhulamungu
uJohn

USewula
uKarin
uJaco

USinyikhaba
uGugu
uDian

UNobayeni
uKara
uRichard
uDenise

1 2 3 4 5 6 7 8 9 10





Tlola ibizo lomntwana ngamunye ekhalendeni yamabeletho.

UTjhirhweni	UMhlolanja	UNtaka
USihlabantangana	UMrhayili	UMgwengweni
UVelabahlinze	URhoboyi	UKhukhulamungu
USewula	USinyikhaba	UNobayeni



Ilanga lami lamabeletho

Teacher:
Sign:
Date:



Ilanga:

Buthelela bewuhlele ngemibala

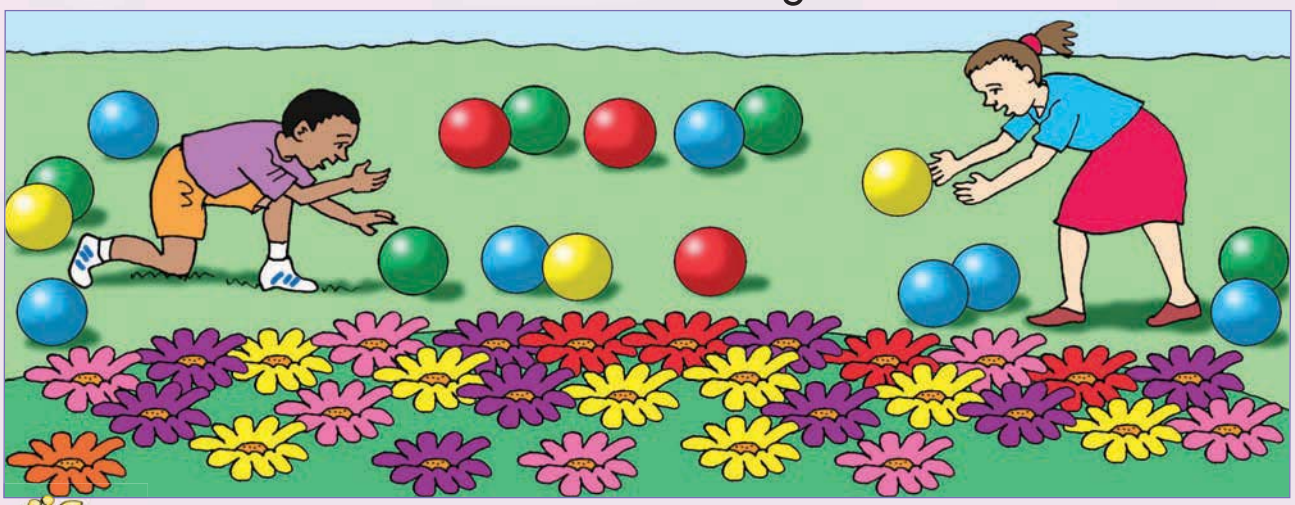



Buthelela bewuhlele iimbholo ngemibala begodu zigwale ngebhoksini elifaneleko.

iimbholo ezihlaza satjani	iimbholo ezibomvu	iimbholo ezihlaza kwesibhakabhaka	iimbholo ezisarulani



Buthelela iimbholo bewuzihlele ngemibala.

				
amabhlomu asarulani	amabhlomu abomvu	amabhlomu asipiridzana	amabhlomu apinki	amabhlomu a-orentji



Hlela izinto ngobungako. Gwala imidwebo yakho.



izinto ezilula

izinto ezibudisi



iimbholo ezincani

iimbholo ezikulu

amabhoksi amancani

amabhoksi amakhulu

Teacher:

Sign:

Date:

Ilanga: _____

Funda bewuhlathulule



Umgwalo wami





Hlela amakhrayoni ngemibala. Gwala imidwebo yawo.





Hlela amakhrayoni ngemibala. Gwala imidwebo yawo.





Hlela abohafu kanye namazungu wekosazana. Agwale.







Phendula imibuzo

		
aboncantathu	aboncazine	iindulungu

Bangaki aboncantathu abalapho? _____

Bangaki aboncazine abalapho? _____

Zingaki iindulungu ezilapho? _____

Ingabe kunaboncantathu abanengi namkha aboncazine abanengi? _____

Ingabe kuneendulungu ezinengi namkha aboncantathu abanengi? _____

Ingabe kunezinye iiyingi nanyana aboncazine? _____

		
nganalitho	ihafu	zeleko

Zingaki iinjege ezingananto lapho? _____

Zingaki iinjege ezihafu lapho? _____

Zingaki iinjege ezizeleko lapho? _____





Teacher:

Sign:

Date:



11 12 13 14 15 16 17 18 19 20

Ilanga: _____

Ngaphambili, ngemva nahlangana

Hlathulula iinomboro ngokusebenzisa amagama ngaphambi, hlangana begodu nangemva.

1	2	3	4	5	6	7	8	9	10	11	12	13	14	15	16	17	18	19	20	21	22	23	24	25

Ibholo yinye ebovu ihlangana neembholo ezimbili ezihlaza kwesibhakabhaka.



Tlola inomboro efaneleko ngaphakathi kwesikwere.

4 6 8

Ngaphambili Hlangana Ngemva

Ngaphambili Hlangana Ngemva

Ngaphambili Hlangana Ngemva

Ngaphambili Hlangana Ngemva

Zalisa iinomboro ezitlhayelako.

	2			5	
	12			15	
13			16		

10			13		
	17			20	
20					25

1 2 3 4 5 6 7 8 9 10 11 12 13 14 15 16 17 18 19 20 21 22 23 24 25

Ngiyiphi inomboro engaphambi kobu- 8? _____

Ngiyiphi inomboro engemva kwe- 16? _____

Ngiziphi iinomboro ezihlangana kobu- 8 ne- 12? _____



Faka iinomboro ezihlangana kwe-14 ne-17 umbala ohlaza kwesibhakabhaka.
Faka inomboro engaphambi kwe-14 umbala obomvu.
Faka inomboro engemva kwe-17 umbala osarulani.

11	12	13	14	15	16	17	18	19	20

11 12 13 14 15 16 17 18 19 20 21 22 23 24 25 26 27 28 29 30

Tlola zoke iinomboro ezisemncameni osarulani.
Sizibizani iinomboro ezisemncameni osarulani.

Tlola zoke iinomboro ezisemncameni opinki.
Sizibizani iinomboro ezisemncameni opinki.

1 2 3 4 5 6 7 8 9 10 11 12 13 14 15 16 17 18 19 20



Hlukanisa umncamo osarulani hlangana nabentwana abambethe okusarulani.

Bafumana imincamo emingaki ngamunye? _____ . Ingabe kusese nomncamo oseleko?

_____ .

Hlukanisa umncamo opinki hlangana nabentwana abambethe pinki. Mingaki imincamo efumanwa mntwana ngamunye? _____ . Ingabe kunomncamo oseleko?

_____ .

Phendula imibuzo elandelako.

Ngiyiphi inomboro elinganako eza ngemva kwe-12? _____
Ngiyiphi inomboro engalinganiko eza ngemva kwe-14? _____
Ngiziphi iinomboro ezingalinganiko eziza hlangana ne-10 ne-16? _____
Tlola phasi iinomboro ezilinganako ezihlangana kobu-8 ne-18? _____

Teacher:
Sign:
Date:



Ilanga:

Iinomboro I–30

Zingaki iincwadi ozibalako?
Zingaki iinjege zepende ozibalako?



1 Mngaki umncamo owubalako?

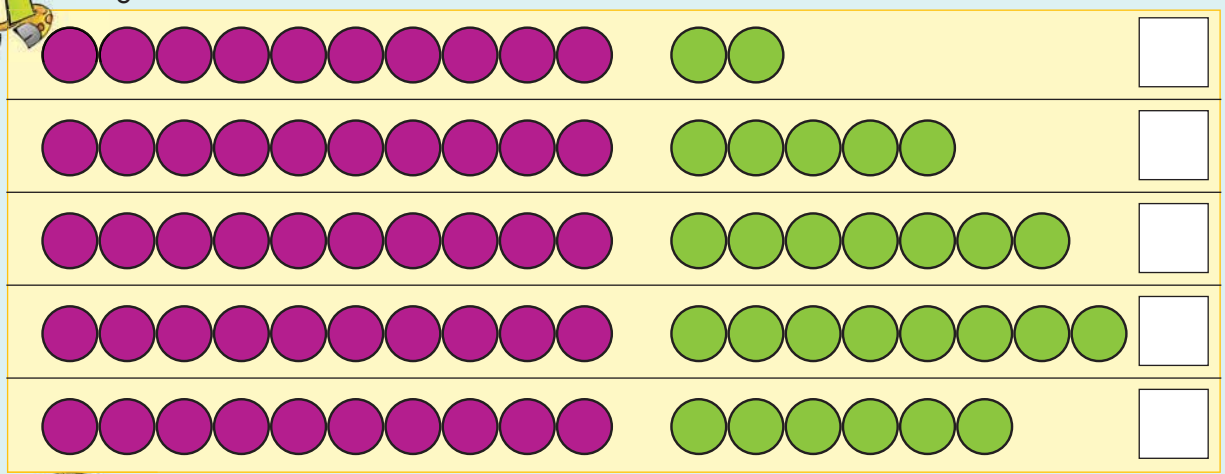

2 Zingaki iincwadi ozibalako?



3 Zalisa inomboro etlhayelako.

14	12	15	17	19	13	26	28	21	30
10 4	2	10	7	10					

1 2 3 4 5 6 7 8 9 10



Qala esibonelweni sokuthoma bese uqedelela okulandelako.

18	=	1	amatjhumi	+	8	amayunidi	namkha	18	=	10	+	8
15	=		amatjhumi	+		amayunidi	namkha		=		+	
19	=		amatjhumi	+		amayunidi	namkha		=		+	
22	=		amatjhumi	+		amayunidi	namkha		=		+	
24	=		amatjhumi	+		amayunidi	namkha		=		+	

Mngaki umncamo owubalako?

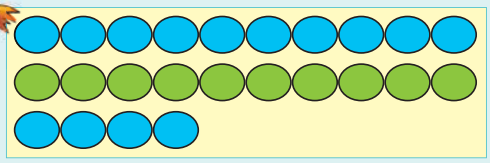

inomboro

singayitlola njenge

20 + ☐ = 24

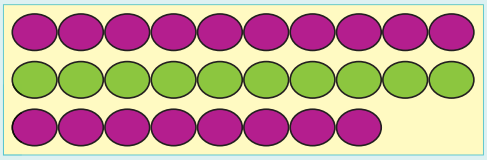

inomboro

singayitlola njenge

20 + ☐ = 28

Tlola amagama weenomboro ezilandelako.

10		11	
12		13	
14		15	
16		17	
18		19	
20		21	
22		23	
24		25	

Qala esibonelweni sokuthoma bese uqedelela okulandelako.

25	=	2	kwetjhumi	+	5	amayunidi		22	=	2	kwetjhumi	+	2	amayunidi
13	=		kwetjhumi	+		amayunidi		21	=		kwetjhumi	+		amayunidi
26	=		kwetjhumi	+		amayunidi		19	=		kwetjhumi	+		amayunidi

Teacher:

Sign:

Date:

11 12 13 14 15 16 17 18 19 20

Ilanga:

Inambalayini





Zalisa iinomboro ezitlhayelako.

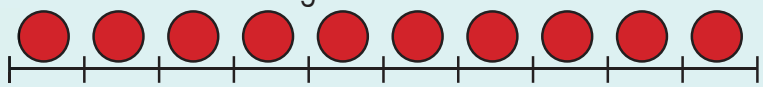

0	1			4						10

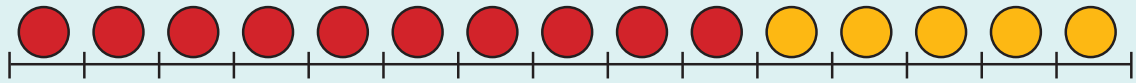

0					5	6								15



Isirhwarhwa seqele kude kangangani?

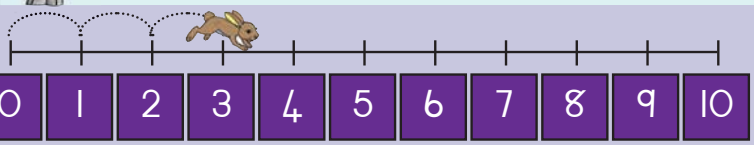

0	1	2	3	4	5	6	7	8	9	10

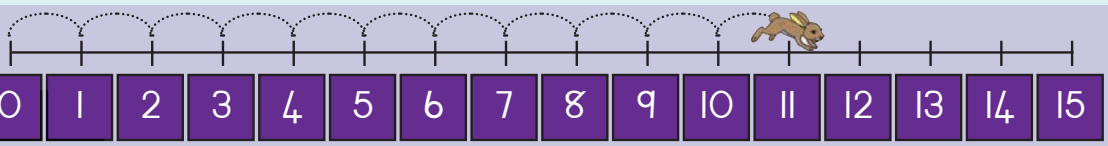

0	1	2	3	4	5	6	7	8	9	10	11	12	13	14	15



Ipunzi yeqele kude kangangani?

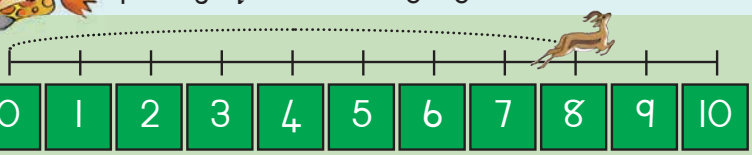

0	1	2	3	4	5	6	7	8	9	10

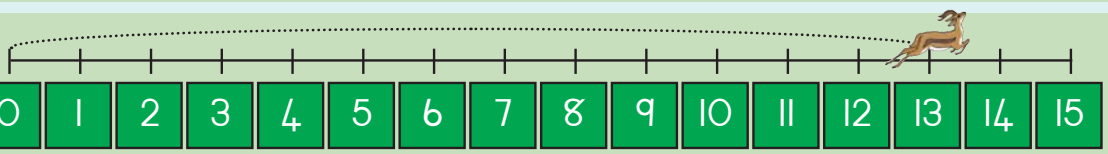

0	1	2	3	4	5	6	7	8	9	10	11	12	13	14	15





Qedelela inambalayini. Isirhwarhwa seqele kude kangangani?

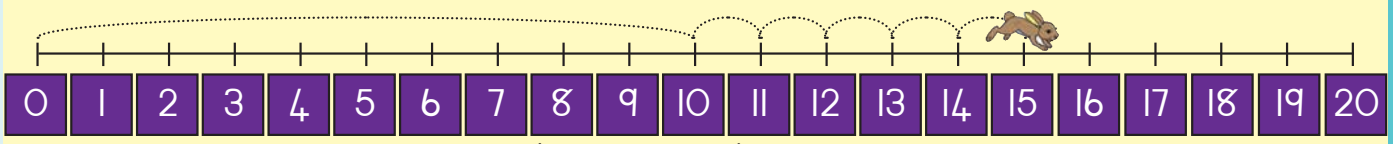

amatjhumi amayunidi

10 + 5 = ____

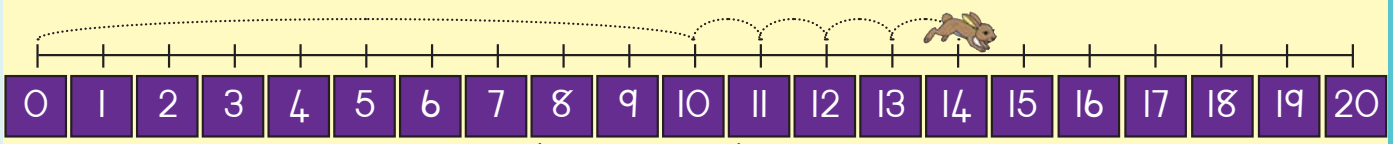

amatjhumi amayunidi

____ + ____ = ____

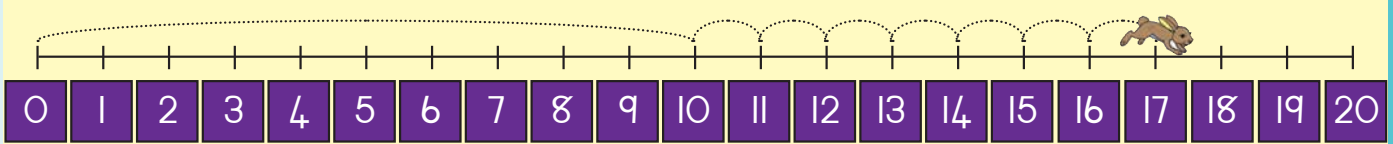

amatjhumi amayunidi

____ + ____ = ____

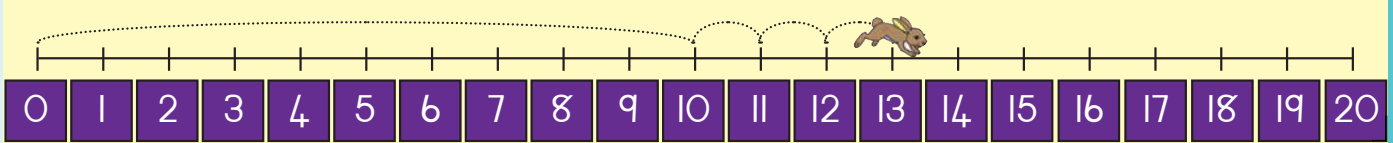

amatjhumi amayunidi

____ + ____ = ____

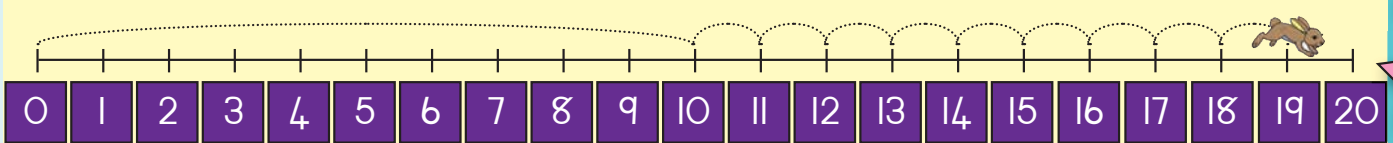

amatjhumi amayunidi

____ + ____ = ____

Teacher:

Sign:

Date:



Ilanga:

Amanambalayini angaphezulu





Siza isirhwarhwa ukutlola isibalo.

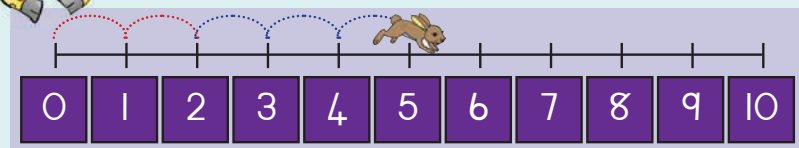

2 + 3 = ☐

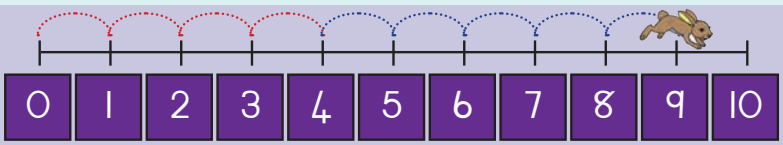

☐ + ☐ = ☐



Siza ipunzi ukutlola isibalo.

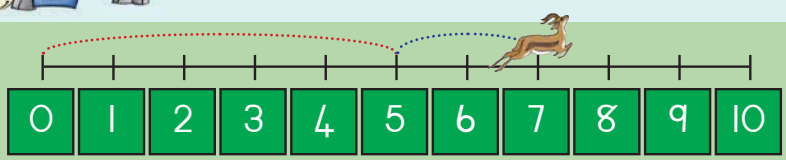

☐ + ☐ = ☐

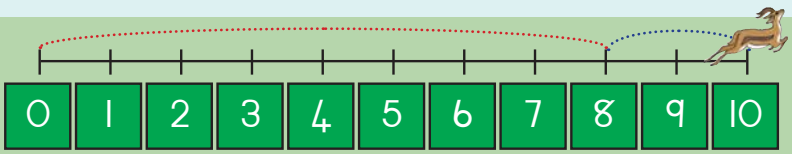

☐ + ☐ = ☐







Siza isirhwarhwa ukutlola isibalo.

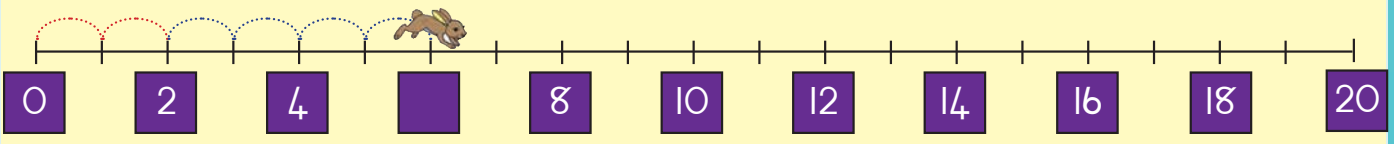

$\square + 4 = \square$

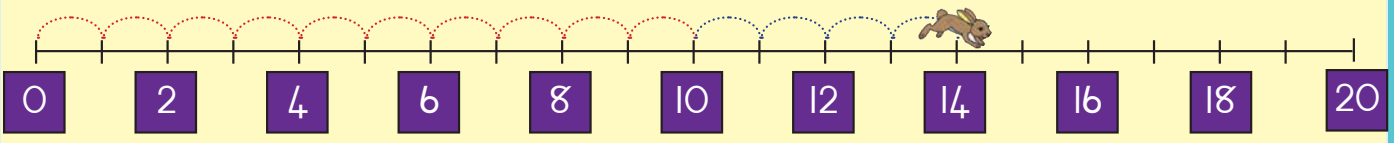

$\square + \square = \square$



Siza ipunzi ukutlola isibalo.

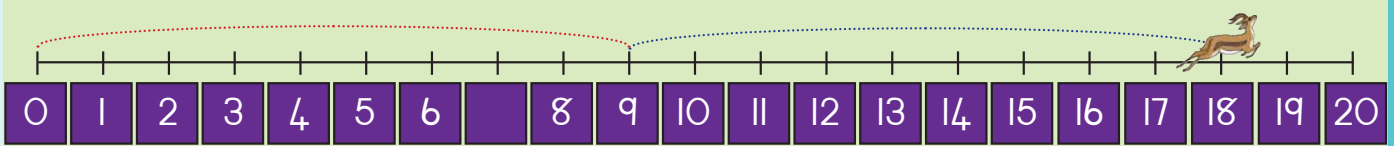

$9 + 9 = \square$

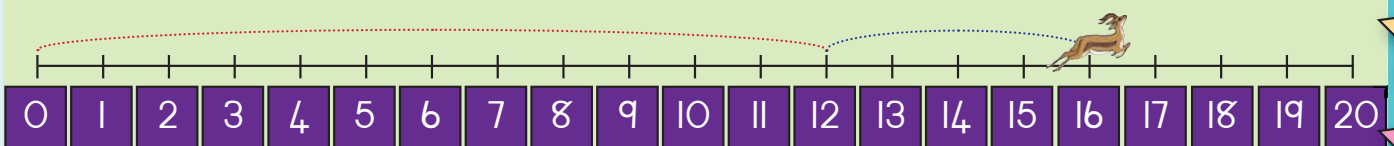

$\square + \square = \square$



Teacher:

Sign:

Date:



Ilanga:

Ukuhlanganisa nokukhupha

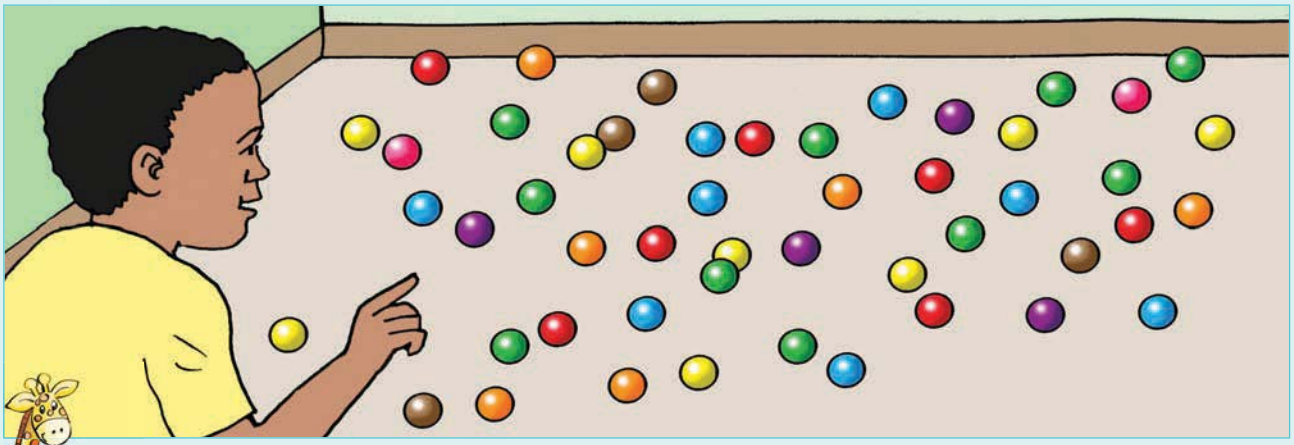



Tlola isibalo somncamo.

Mingaki imincamo ebomvu lapho?

Mingaki imincamo ehlaza kwesibhakabhaka lapho?

Mingaki imincamo ehlaza satjani lapho?

Mingaki imincamo esalamune lapho?

Mingaki imincamo esipiridzana lapho?

Seyiyoke mngaki umncamo nawuhlangeneko?



Tlola isibalo somncamo ngemabhoksini af aneleko bese uyawahlanganisa.

obomvu	+	ohlaza satjani	=	
osarulani	+	opinki	=	
o-salamune	+	ohlaza kwesibha-kabhaka	=	
osipiridzana	+	ohlaza satjani	=	
obhraweni	+	osarulani	=	



Qedelela amaphetheni.



Sebenzisa imincamo ukuzalisa amabhoksi.

8 + 7 =	15
8 + 2 + 5 =	
9 + =	
9 + + =	

Madanisa isithombe nesibalo bese unikela ipendulo.

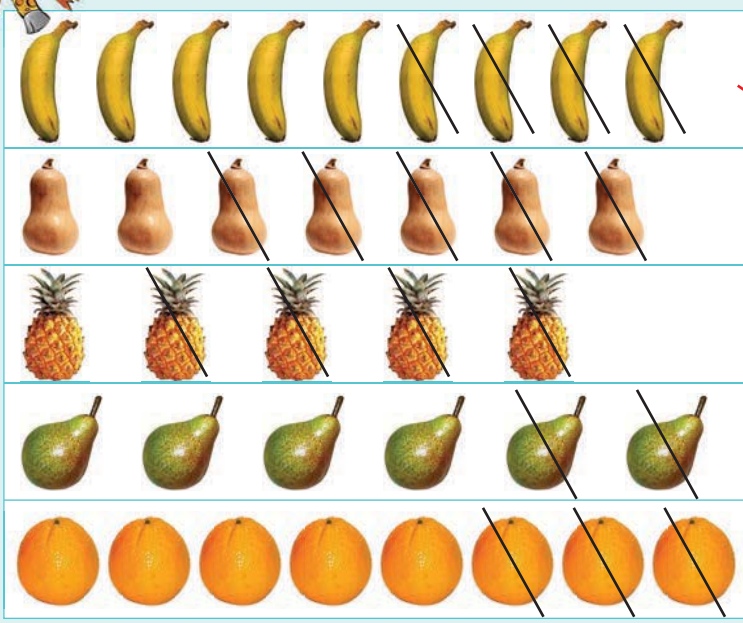

7 – 5 =	
9 – 4 =	
8 – 3 =	
5 – 4 =	
6 – 2 =	

Tlola isibalo se.

9 – 6 = 3	– =
– =	– =

Teacher:
Sign:
Date:

Ilanga: _____

Amalanga, iimveke neenyanga

UMvulo
ULesibili
ULesithathu
ULesine
ULesihlanu
UMgcibelo
USondo

UTjhirhweni	UMhlolanja	UNtaka
USihlabantangana	UMrhayili	UMgwengweni
UVelabahlinze	URhoboyi	UKhukhulamungu
USewula	USinyikhaba	UNobayeni



Phendula imibuzo elandelako ngeemveke.

Ngiliphi ilanga eliza ngaphambi koLesithathu? _____

Ngiliphi ilanga eliza ngemva koLesithathu? _____

Ngiliphi ilanga eliza ngemva koMgcibelo? _____

Ngiliphi ilanga eliza hlangana koMvulo noLesithathu? _____

Nakhibe uMvulo lilanga loku-I, kutjho kobana uLesihlanu lilanga _____

Ngimaphi amalanga eza hlangana koLesithathu noMgqibelo? _____

_____



Phendula imibuzo elandelako ngeenyanga.

Ngiyiphi inyanga eza ngemva kwakaSihlabantangana? _____

Ngiyiphi inyanga eza ngemva koMgwengweni? _____

Ngiyiphi inyanga eza hlangana koRhoboyi noSewula? _____

Ngiziphi iinyanga eziza hlangana noTjhirhweni noMgwengweni? _____

Ngiyiphi inyanga yokuthoma emnyakeni? _____

Ngiyiphi inyanga yamaswaphela emnyakeni? _____



Iinkolo ze -

Sewula Afrika



Iminyanya yomlando

ILanga lamaLungelo woBuntu

ILanga leKululeko

ILanga labaSebenzi

ILanga leLutjha

ILanga laBomma leNarha mazombe

Ilanga lamaGugu

ILanga lokuBuyisana

Ilanga lamabeletho

Ilanga lami lamabeletho





Sika 2: Sika bese unamathisela ekhalendeni yeenyanga amalanga amathathu wezekolo acwengileko begodu namalanga wamaholideyi weSewula Afrika woke.

UTjhirhweni	UMhlolanja	UNtaka
USihlabantangana	UMrhayili	UMgwengweni
UVelabahlinze	URhoboyi	UKhukhulamungu
USewula	USinyikhaba	UNobayeni



Teacher:

Sign:

Date:



Ilanga:

Ukuhlanganisa

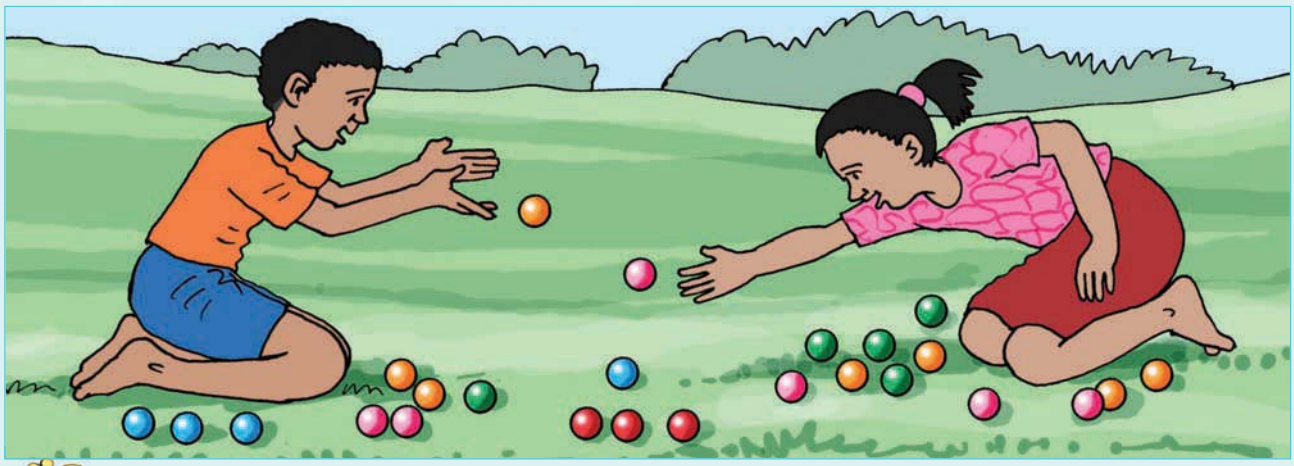

Qala esithombeni bese uhlanganisa amamabula.

abomvu	+	ahlaza kwesibhakabhaka	=	3	+	4	=	
ahlaza satjani	+	ahlaza kwesibhakabhaka	=		+		=	
apinki	+	ahlaza kwesibhakabhaka	=		+		=	
ahlaza satjani	+	a-orontji	=		+		=	
abomvu	+	ahlaza satjani	=		+		=	
a-orontji	+	ahlaza kwesibhakabhaka	=		+		=	

Hlanganisa.

3 + 2 =	4 + 6 =	9 + 3 =
6 + 5 =	7 + 8 =	8 + 4 =
9 + 5 =	8 + 6 =	7 + 4 =
9 + 9 =	7 + 5 =	8 + 8 =
7 + 6 =	9 + 6 =	7 + 7 =

Tlola inani le.

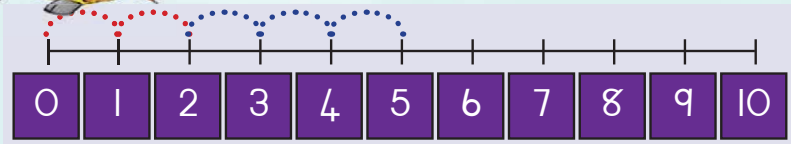

2 + 3 = 5

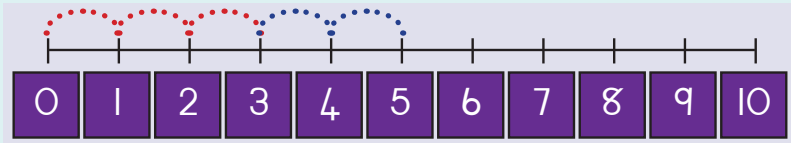

__ + __ = __

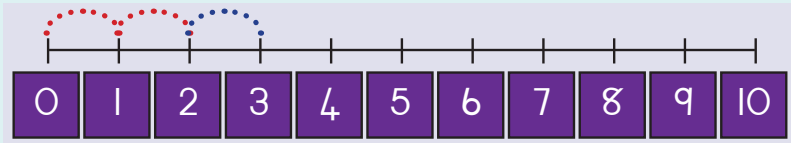

__ + __ = __

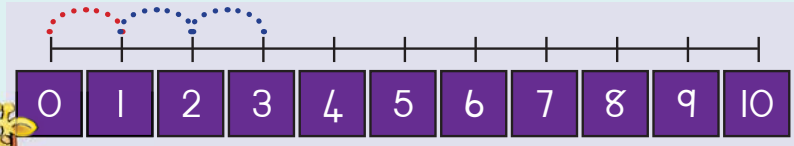

__ + __ = __

Yenza iinkala zilingane.

5 = 1 + 4

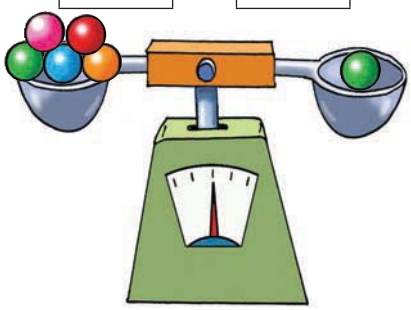

6 = 2 + __

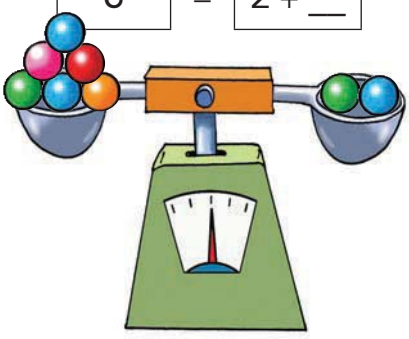

3 + __ = __

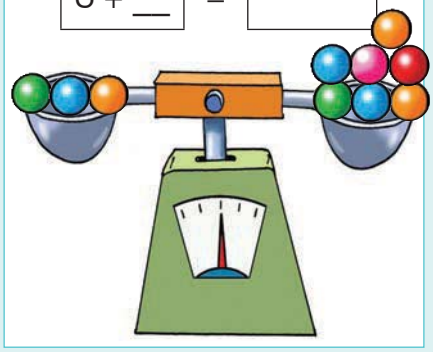

2 + 1 = 1 + __

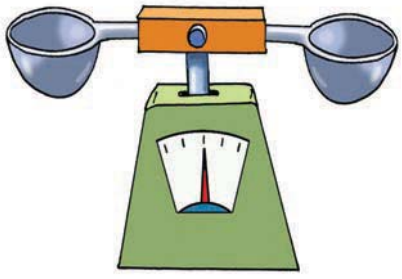

6 + 3 = 3 + __

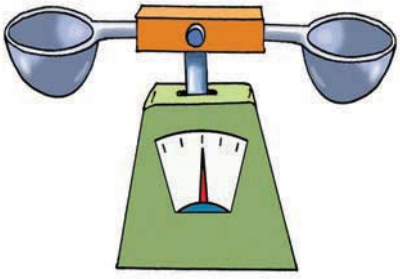

2 + __ = 8 + 2

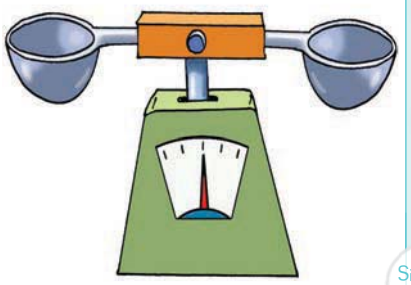

Teacher:

Sign:

Date:

11 12 13 14 15 16 17 18 19 20

Ilanga:

Ukukhupha

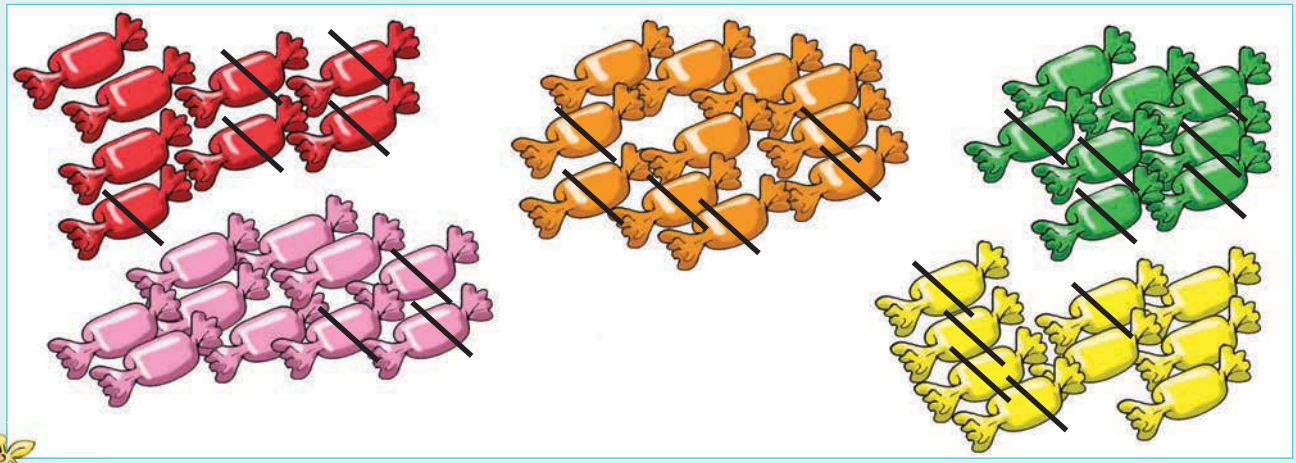

Qala esithombeni bese utlola ithothali kakhupha.

amaswidi abomvu	=	8	–	5	=	3
amaswidi ahlaza satjani	=		–		=	
amaswidi asarulani	=		–		=	
amaswidi a-salamune	=		–		=	
amaswidi apinki	=		–		=	

Khupha.

5 – 3 =	10 – 6 =	12 – 3 =
11 – 5 =	15 – 7 =	12 – 4 =
14 – 9 =	14 – 8 =	11 – 4 =
18 – 9 =	12 – 5 =	16 – 8 =
13 – 7 =	15 – 6 =	14 – 7 =



Qedelela.

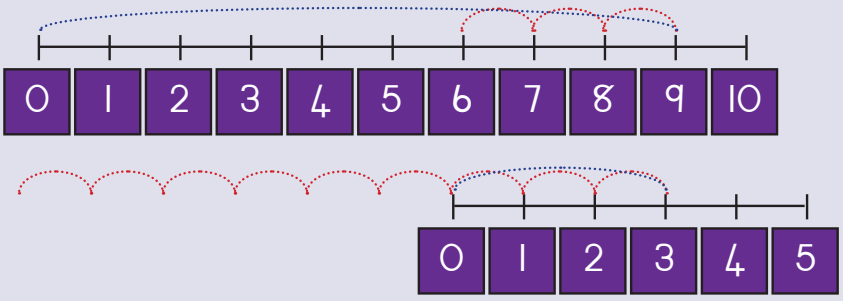

9 – 3

Akulingani na

3 – 9

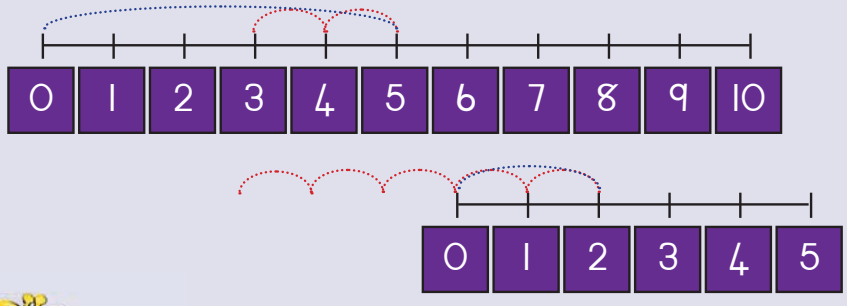

5 – 2

Akulingani na

2 – 5

Tlola isibalo se:

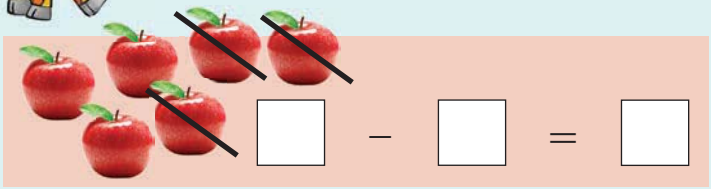

□ – □ = □



□ – □ = □



□ – □ = □



□ – □ = □



□ – □ = □

Teacher:

Sign:

Date:





Ilanga:

Ukukhupha (kuragela phambili)



Madanisa amakarada.

2 10	8 10	7 10	5 10	3 10

7 + 10 = 17	10 + 2 = 12	10 + 5 = 15	3 + 10 = 13	10 + 8 = 18



Sebenzisa inambalayini. Tlola isibalo sokukhupha. Qala isibonelo.

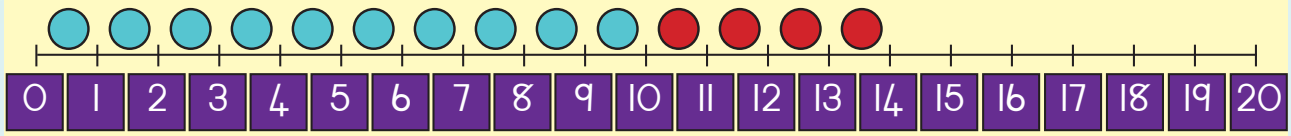

10 + 4 = 14

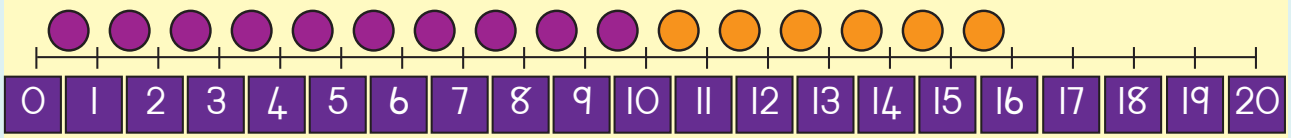

__ + __ = __

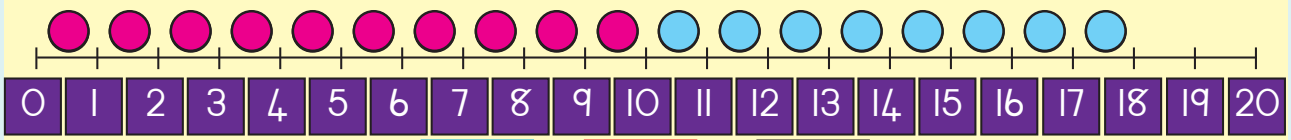

__ + __ = __

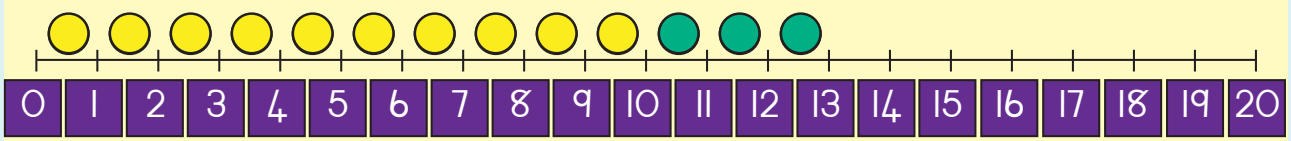

__ + __ = __







Ukukhupha.

10	+	3	=	13	10	+	2	=	
10	+	5	=		10	+	7	=	
10	+	1	=		10	+	6	=	
10	+	4	=		10	+	8	=	
10	+	9	=		10	+	3	=	



Hlanganisa.

16 + 13

10		10		20			
6	+	3	=	9			
16	+	13	=	29			

14 + 12

10		10					
4	+	2	=				
	+		=				

17 + 11

10		10					
7	+	1	=				
	+		=				

15 + 13

10		10					
5	+	3	=				
	+		=				

16 + 12

10		10					
6	+	2	=				
	+		=				

18 + 12

10		10					
8	+	2	=				
	+		=				



ULisa uneembalisi ezili-9 bese uPeter abe nezibu-8.





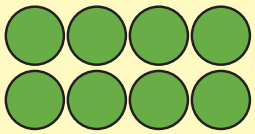



Yini inani leembalisi?

Teacher:
Sign:
Date:



Ilanga:

Imali

1 Yini engaphakathi kwebhanga yami yef arigana?



2 Sika imali emumuwa kuSika-3 bese uyinamathisela inani elif aneleko endaweni enembako.

50c	70c
90c	60c
40c	80c





Bangaki abosende?

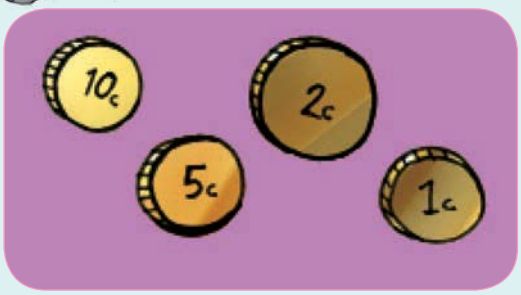

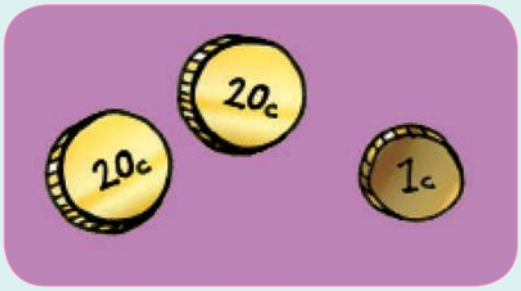

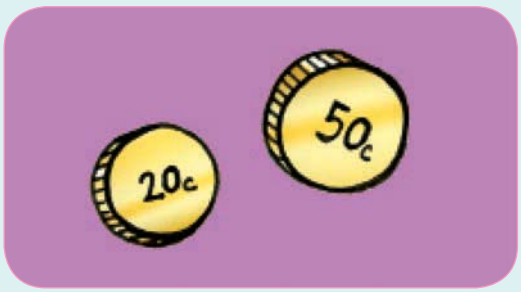



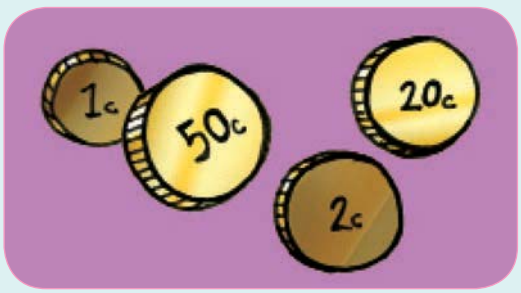

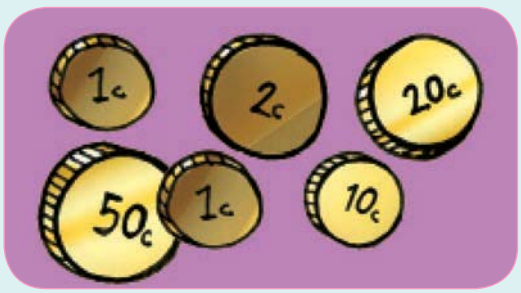



Iimbalo zamagama:

USuzi una-50c. Unina umngezelelela nga-20c ngaphezulu. USuzi sele anamalini?

_____

Ngina-90c. Ngithenga amaswidi nga-30c. Ngisele ngemalini?

_____

Teacher:

Sign:

Date:

Ilanga:

Imali yamaphepha

1 Yimalini imali engepheseni yami?

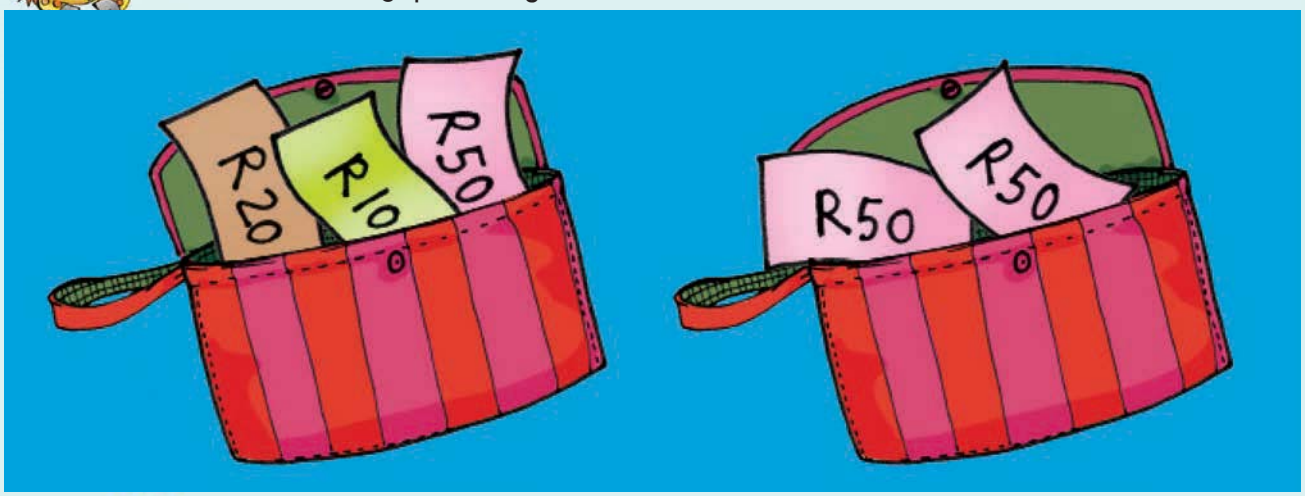

2 Sika imali yamaphepha kuSika we-3 bese unamathisela inani elifaneleko endaweni enembako.

	
	
	

Mangaki amaRanda?





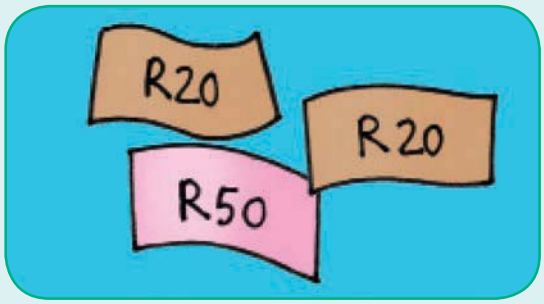







Iimbalo zamagama:

Ngizibulungele ama-R50. Ngifunyene ama-R20 ngelanga lami lamabeletho. Senginamalini seyiyoke?

_____

Nginama-R90. Ngithenga incwani ngama-R30. Ngisele ngamalini?

_____

Teacher:
Sign:
Date:

11 12 13 14 15 16 17 18 19 20

Ilanga:

Amaphetheni

1 Wahla iphetheni.

wahla wahla wahla wahla wahla wahla wahla wahla wahla wahla wahla



wahla wahla wahla wahla wahla wahla wahla wahla wahla wahla wahla

Kopulula amaphetheni alandelako.

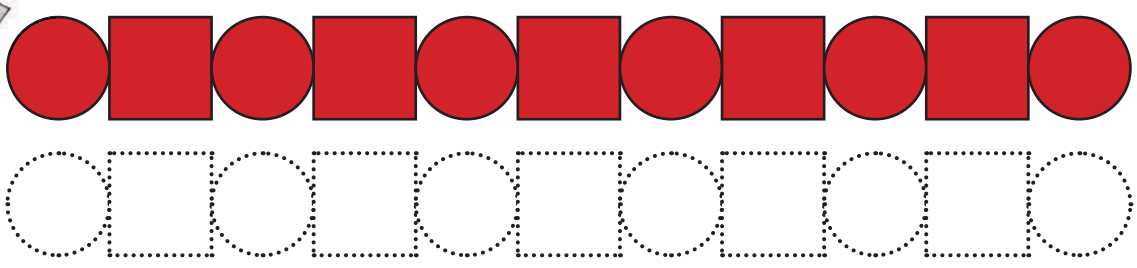



Kopulula amaphetheni.





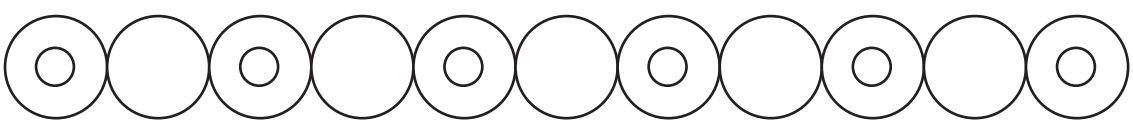

Teacher:

Sign:

Date:

11 12 13 14 15 16 17 18 19 20

Ilanga:

Amaphetheni

1 Hlathulula iphetheni ngayinye ngamagama. Amagama angenzasi kungenzeka akusize.



uncazine | isikwere | uncantathu | indulungu | imibala

2 Faka iphetheni elandelako umbala.

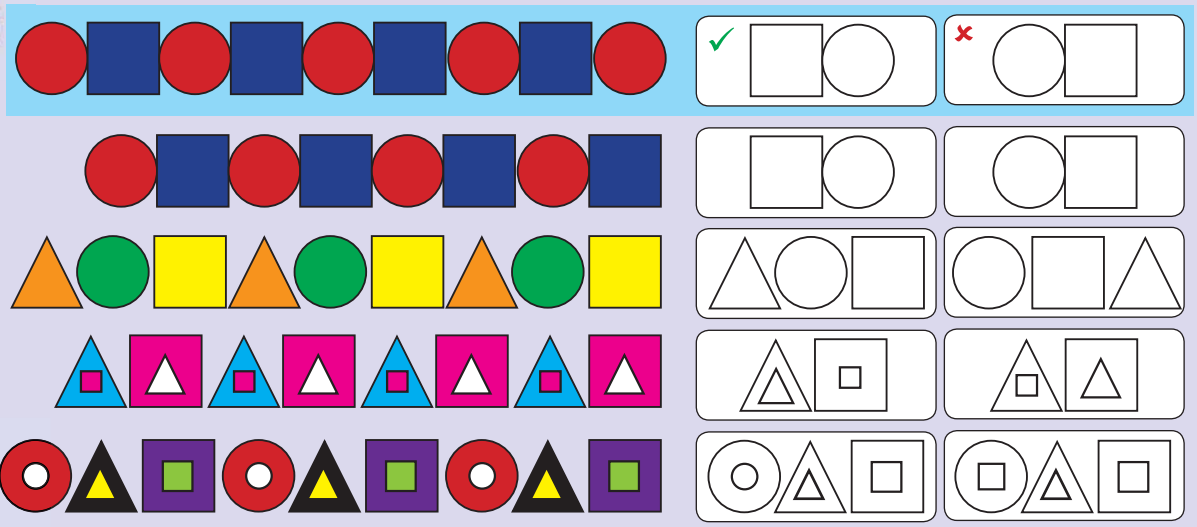

3 Gwala iphetheni elandelako.



4 Ngezelela iphetheni.

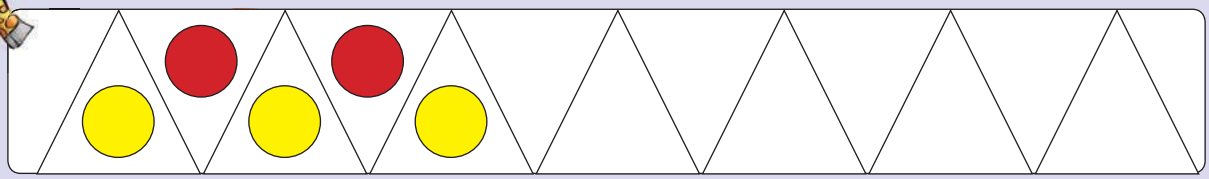





Gwala amaphetheni wakho ngokusebenzisa  .



Gwala iphetheni elandelako.

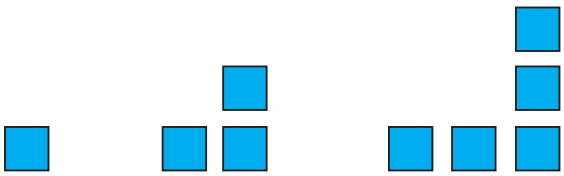





Qedelela okulandelako wenzele kobana ube nendulungu yinye kwaphela ngaphezulu.

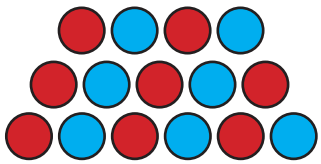

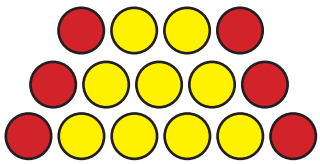





Yenza amaphetheni wombala wakho ngokusebenzisa amabumbeko angenzasi.

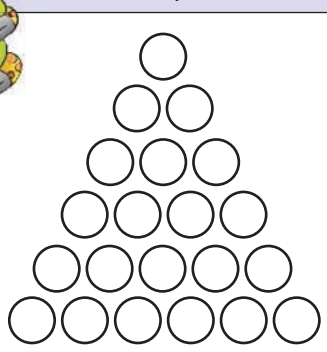

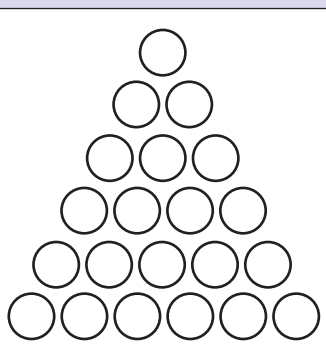

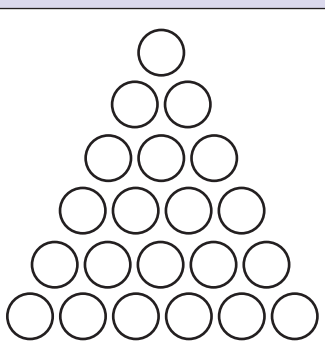



Teacher:

Sign:

Date:



11 12 13 14 15 16 17 18 19 20

Ilanga:

Ukubuyabuyelela x 2

1 Mangaki amaswidi asethebuleni ngayinye?



Uwabale njani amaswidi?
(Abanye abentwana bangathi 1,2,3... abanye bangathi 2,4,6...)

2 Qedelela okulandelako. Qala isibonelo.



iinqhema ezi-4 zangaba-2	2 + 2 + 2 + 2 = 8	4 × 2 = 8
iinqhema ezi-5 zangaba- 2	2 + 2 + 2 + 2 + 2 =	5 × 2 =
iinqhema ezi-6 zangaba-2	2 + 2 + 2 + 2 + 2 + 2 =	6 × 2 =
iinqhema ezi-7 zangaba-2	2 + 2 + 2 + 2 + 2 + 2 + 2 =	7 × 2 =
iinqhema ezibu-8 zangaba-2	2 + 2 + 2 + 2 + 2 + 2 + 2 + 2 =	8 × 2 =

3 Yenza umgwalo wokulandelako.

iinqhema ezi-3 zangaku-2	iinqhema ezi-4 zangaku-2	iinqhema ezi-9 zangaku-2



Gwala umqwalo wokulandelako.

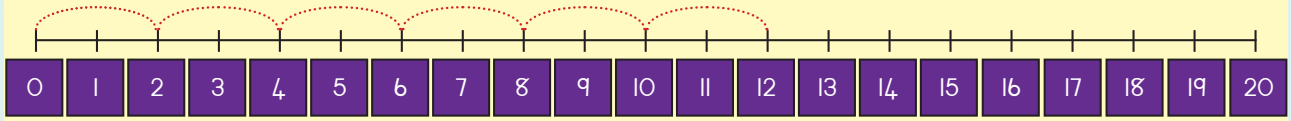

2, 4, 6, 8, ___ , ___

2 + 2 + 2 + 2 + 2 + 2 = ☐

6 × 2 = ☐

Umgwalo



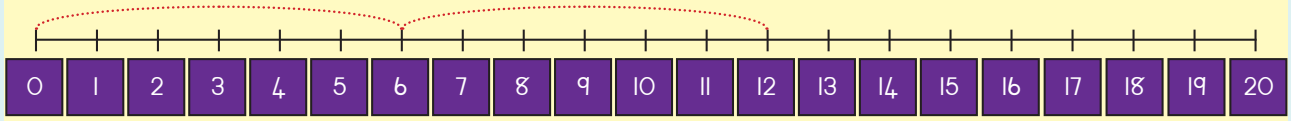

6, ___

6 + ☐ = ☐

2 × ☐ = ☐

Umgwalo



Isiswebu sinye sinamehlo ama-8. Iinswebu ezili-7 zinamehlo amangaki?

☐



2 4 6 8 10 12 14

16 18 20 22 24 26

Teacher:

Sign:

Date:



Ilanga:

Ukubuyabuyelela x 5

1 Mangaki amaswidi asetheyibuleni ngayinye?



2 Qedelela okulandelako: Qala isibonelo.



iinqhema ezi-3 zangaku-5	5 + 5 + 5 = 15	3 × 5 = 15
iinqhema ezi-2 zangaku-5	5 + 5 =	2 × 5 =
iinqhema ezi-4 zangaku-5	5 + 5 + 5 + 5 =	4 × 5 =
iinqhema ezi-6 zangaku-5	5 + 5 + 5 + 5 + 5 + 5 =	6 × 5 =
iinqhema ezi-7 zangaku-5	+ + + + + + =	7 × 5 =

3 Gwala umdwebo wokulandelako.

iinqhema ezi-3 zangaku-5	iinqhema ezi-4 zangaku-5	iinqhema ezi-5 zangaku-5





Gwala umdwebo wokulandelako.

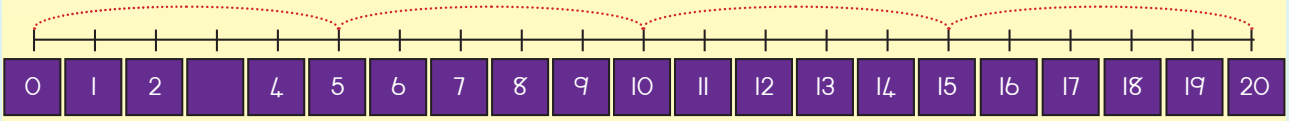

5, 10, 15, ___

5 + 5 + 5 + 5 = ☐

4 × 5 = ☐

Umgwalo

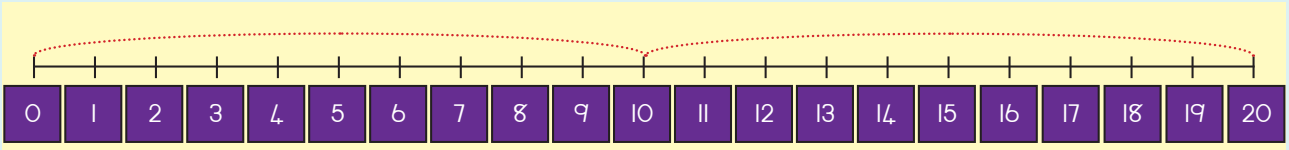

10, ___

10 + ☐ = ☐

10 × ☐ = ☐

Umgwalo



5 10 15 20 25 30

35 40 45 50



Teacher:

Sign:

Date:



Ilanga:

Iindatjana ezinengi zokubuyabuyelela

Yenza iindatjana yakho ngokusebenzisa isibalo esipheleleko seendlebe, izandla neenyawo.



Sibangani abali-10. Sinezandla ezingaki?

Gwala umdwebo.

Kutjengise ngeembalisi.

Kutjengise kunambalayini.

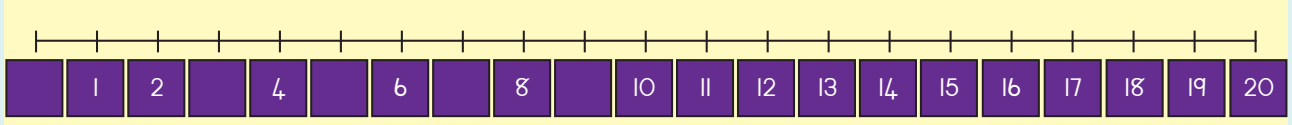

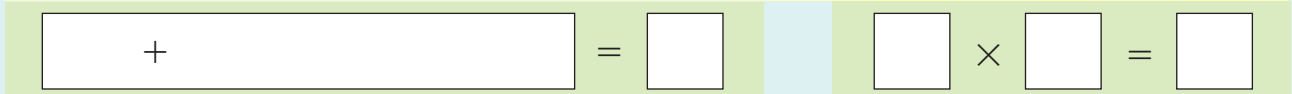







Umndeni kaSusan uneempara ezili-10 zamanyathelo.
Mangaki amanyathelo abanawo?

Gwala umdwebo.

Kutjengise ngeembalisi.

Kutjengise kunambalayini.

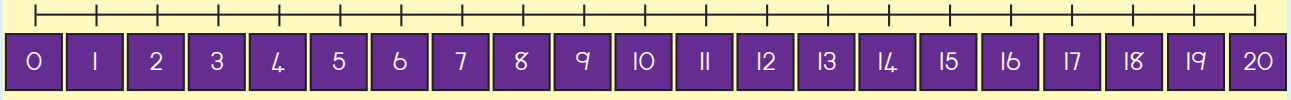



+ = × =

Tlola indatjana yakho ngokusebenzisa abentwana abasi-6 nezandla zabo.



5 10 15 20 25 30 35



11 12 13 14 15 16 17 18 19 20

Teacher:
Sign:
Date:

Ilanga:

Iinkwere, aboncazine, aboncantathu begodu neendulungu (kuragelaphambili)



Faka zoke iimbholo umbala obomvu, amabhoksi abe hlaza kwesibhakabhaka begodu amasilinda abe nombala ohlaza satjani.

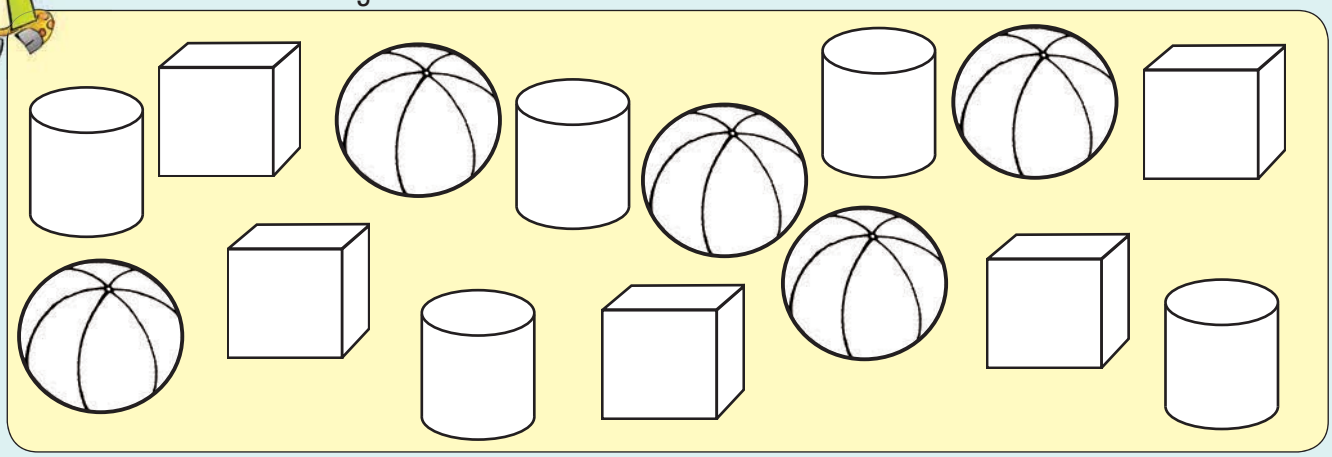

Khetha igama elifaneleko.

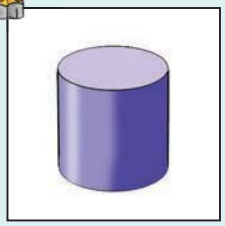

imiphetho ebunqopha

imiphetho ezombelezako

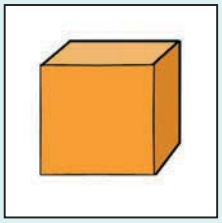

imiphetho ebunqopha

imiphetho ezombelezako



imiphetho ebunqopha

imiphetho ezombelezako

Itjho nakhibe into izokugedeka namkha izokutjhelela.



gedeka

tjhelela

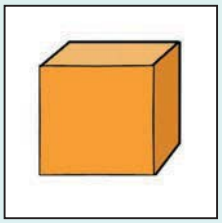

gedeka

tjhelela



gedeka

tjhelela

Kungaki okubonako ezintweni lezi ezisesithombeni: amasilinda, amabhoksi kunye neembholo.





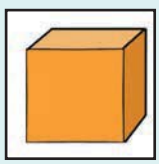



Gwala isithombe sakho ngokusebenzisa iimbholo, amabhoksi begodu namasilinda.

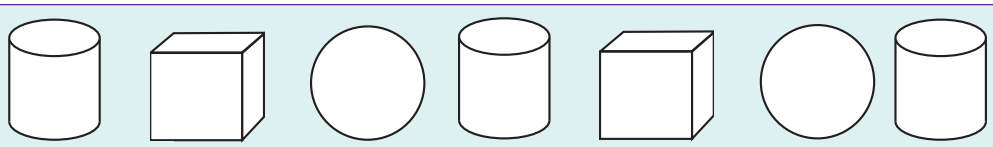

Teacher:

Sign:

Date:

11 12 13 14 15 16 17 18 19 20

Ilanga:

Landelanisa bewulinganise iinomboro: 1–40

Ngubani onama-lamune amanengi?





Ngubani onama-apula amanengi?





Bala umncamo bese uzalise amabhoksi anganalitho.

1	2	3	4	5		7			10
	12				16		18		
21				25	26				30
31					36				40

Qala umncamo bese uphendula imibuzo.

Ngiyiphi inomboro encani kunaku-8? ☐

Ngiyiphi inomboro ekulu kunama-13? ☐

Ngiyiphi inomboro encani kunaku-20? ☐

Ngiyiphi inomboro encani kunaku-24? ☐





Faka iinomboro ezincani kune-10 umbala ohlaza kwesibhakabhaka bese kuthi ezikulu kune-10 uzifake obomvu.

1	2	3	4	5	6	7	8	9	10
11	12	13	14	15	16	17	18	19	20

Faka iinomboro ezincani kunama-30 nezikulu kunama-24 umbala ohlaza kwesibhakabhaka.

20	21	22	23	24	25	26	27	28	29	30

Faka iinomboro ezincani kunama-40 umbala ohlaza kwesibhakabhaka begodu ezikulu kunama-36 umbala osarulani.

30	31	32	33	34	35	36	37	38	39	40

Faka iinomboro ezilinganako umbala osarulani begodu ufake iinomboro ezingalinganiko umbala ohlaza satjani.

1	2	3	4	5	6	7	8	9	10
11	12	13	14	15	16	17	18	19	20
21	22	23	24	25	26	27	28	29	30
31	32	33	34	35	36	37	38	39	40
41	42	43	44	45	46	47	48	49	50



Ngiyiphi inomboro engalinganiko eza ngemva kwe-10?

Ngiyiphi inomboro elinganako eza ngaphambi kwe-10?

Tlola phasi iinomboro ezilinganako ezihlangana kwe-14 nama-28?

Tlola phasi iinomboro ezingalinganiko ezihlangana koku-5 nokuli-15?

Ngiyiphi inomboro eza ngemva kwama-21?

Ngiyiphi inomboro elinganako eza ngaphambi kwama-24?

Tlola phasi iinomboro ezilinganako ezihlangana kwama-20 nama-30?

Tlola phasi iinomboro ezingalinganiko ezihlangana kwama-20 nama-30?



Teacher:
Sign:
Date:



Ilanga:

Landelanisa begodu umadanise: 40–50



Bala umncamo bese uzalisa amabhoksi anganalitho.

1	2	3	4	5					
								19	
							28		

	32								
									50
51	52	53	54	55	56	57	58	59	60

Ngiyiphi inomboro encani kunaku-3? ☐

Ngiyiphi inomboro ekulu kunama-31? ☐

Ngiyiphi inomboro encani kunama-38? ☐

Ngiyiphi inomboro encani kunama-47? ☐





Faka iinomboro ezincani kunama-40 umbala begodu nezikulu kunama-36 ngombala ohlaza satjani.

30	31	32	33	34	35	36	37	38	39	40

Iinomboro ezincani kunama-40.

Iinomboro ezikulu kunama-36



Faka iinomboro ezilinganako umbala osarulani begodu ufake iinomboro ezingalinganiko umbala ohlaza satjani

40	41	42	43	44	45	46	47	48	49	50

Ngiyiphi inomboro emswenya elandela ngemva kwama-40?

Ngiyiphi inomboro elinganako elandela ngemva kwama-43?

Tlola inomboro elinganako ehlangana kwama-40 nama-50?

Tlola iinomboro ezimswenya esihlangana kwama-40 nama-50?

Ngiyiphi inomboro elinganako elandela ngemva kwama-40?

Ngiyiphi inomboro elinganako elandela ngemva kwama-41?



Teacher:

Sign:

Date:



Ilanga:

Iinomboro 40–50



Bala inani lomncamo?

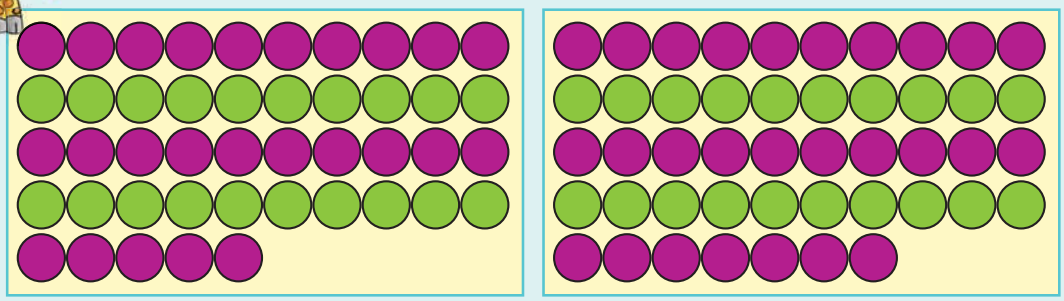

inomboro	Singayitlola njenge				inomboro	singayitlola njenge			
45	40	+	5	=	45		+		=	

Qedelela okulandelako.

20	21	22							
30				34					
		42							

Qedelela okulandelako.

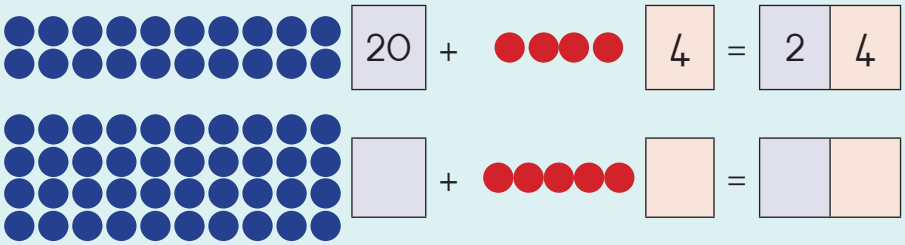

20	+		4	=	2	4
	+			=		



Tlola amagama we.

41	_____	42	_____
43	_____	44	_____
45	_____	46	_____
47	_____	48	_____
49	_____	50	_____

Qala esibonelweni sokuthoma bese uqedelela aseleko.

45	=	4	amatjhumi	+	5	amayunidi
43	=		amatjhumi	+		amayunidi
42	=		amatjhumi	+		amayunidi

44	=		amatjhumi	+		amayunidi
41	=		amatjhumi	+		amayunidi
48	=		amatjhumi	+		amayunidi

Tlola inomboro ngaphakathi kwekholomu elifaneleko.

	Amatjhumi	Amayunidi
27		
34		
46		
41		
39		

Teacher:
Sign:
Date:

11 12 13 14 15 16 17 18 19 20

Ilanga:

Iinkwere, aboncazine, aboncantathu begodu neendulungu

Ugogo wenza isendlalo sombhede esihle khulu. Khomba woke amabumbeko.

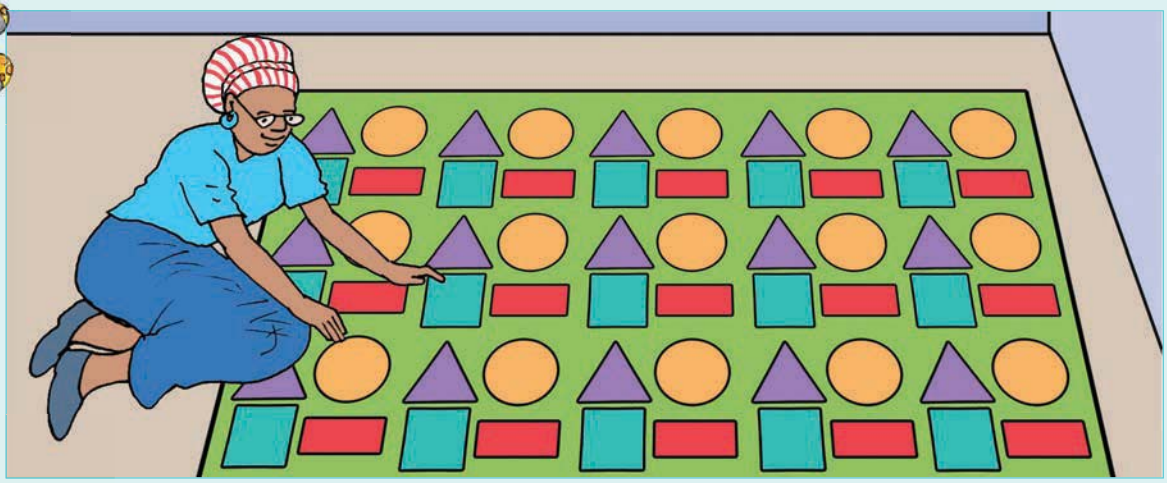

Faka iinkwere umbala ohlaza kwesibhakabhaka, aboncazine osarulani, aboncantathu ngombala ohlaza satjani begodu iindulungu ngombala obomvu.



Khetha ipendulo efaneleko.



imiphetho ebunqopha

imiphetho eyindulungu



imiphetho ebunqopha

imiphetho eyindulungu



imiphetho ebunqopha

imiphetho eyindulungu



imiphetho ebunqopha

imiphetho eyindulungu

Zingaki  begodu  namarekthengela owabalako?



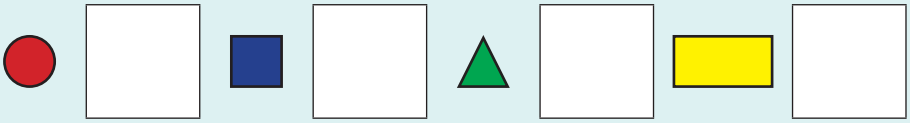

Gwala isithombe sakho ngokusebenzisa iindulungu, iinkwere, aboncantathu begodu namarekthengela.

Teacher:
Sign:
Date:

11 12 13 14 15 16 17 18 19 20

Ilanga:

Umbalo-nengi 1–20

Ukukhumbula masinyazana.

4 + 5 − 1 =	13 − 9 + 2 =	20 − 7 + 1 =	10 + 5 − 4 =
10 + 3 + 2 =	9 + 3 − 2 =	8 − 2 − 1 =	13 − 8 + 1 =
9 − 4 − 3 =	18 − 9 − 4 =	7 + 8 + 1 =	16 − 7 + 3 =
14 − 6 + 4 =	12 − 5 − 2 =	19 − 10 + 5 =	6 + 5 − 3 =

Hlanganisa okulandelako.

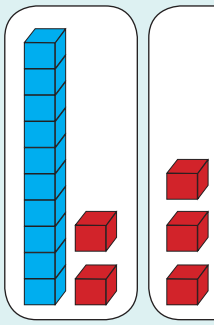

= 10 2 + 6

= 10 + 8

= 18

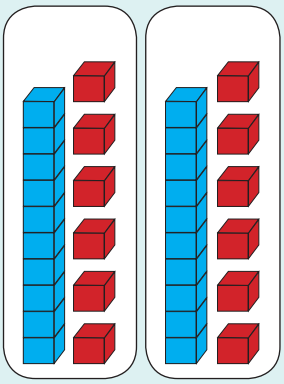

= + + =

= + =

= + =

=

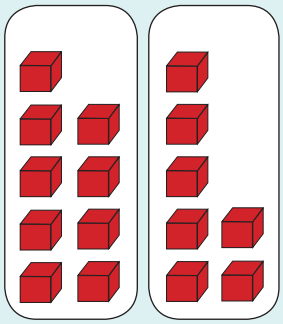

= + =

= + =

=



Khupha okulandelako.

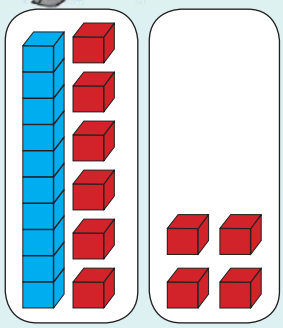

= 10 6 − 4

= 10 − 2

= 8

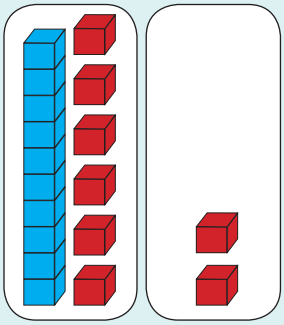

= ☐ ☐ + ☐ ☐

= ☐ − ☐

= ☐

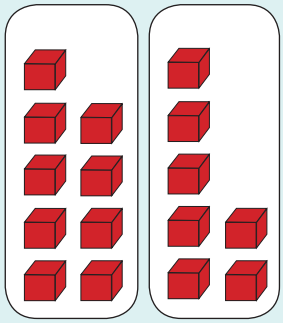

= ☐ − ☐

= ☐



Ngathenga amaswidi ali-15. Ngadla ma-2. Nganikela umngani wami ma-4. Ngisele namaswidi amangaki?





11 12 13 14 15 16 17 18 19 20

Teacher:

Sign:

Date:

Ilanga:

Umbalo-nengi 20–50

Ukukhumbula masinyazana.

20 + 2 – 1 =	36 – 6 + 2 =	42 – 2 + 4 =	47 + 4 – 1 =
30 + 3 + 6 =	42 + 9 – 1 =	33 – 2 – 1 =	49 – 1 + 2 =
55 – 5 – 0 =	38 – 7 – 1 =	45 + 1 + 2 =	50 – 5 + 3 =
24 – 3 + 2 =	32 – 5 – 2 =	49 – 10 + 1 =	29 + 5 – 4 =

Hlanganisa okulandelako.

Kwanje linga ngeyakho indlela.

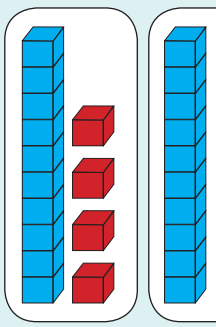

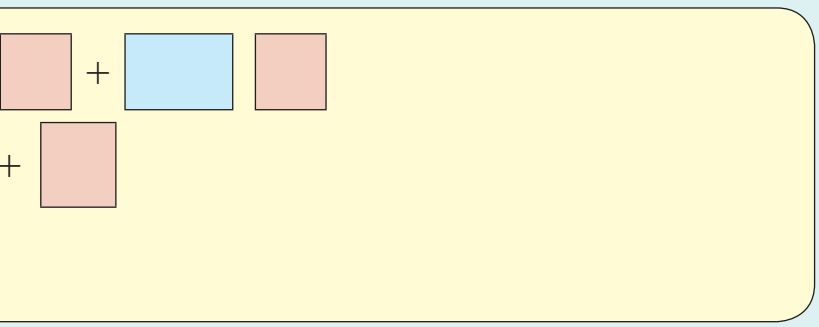

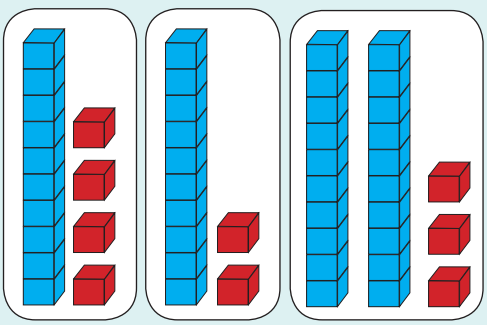

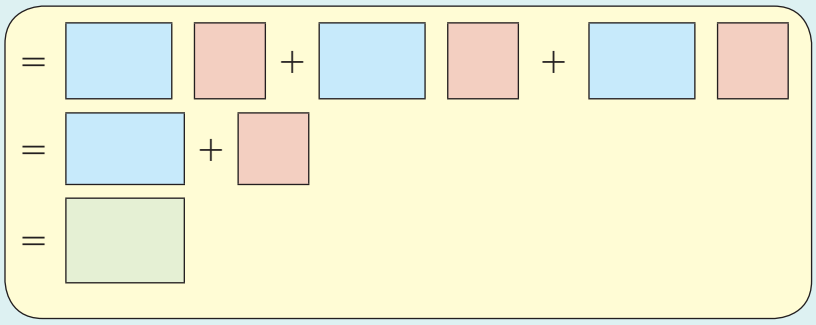

Kwanje linga ngeyakho indlela.

Khupha okulandelako.

Kwanje linga ngeyakho indlela.

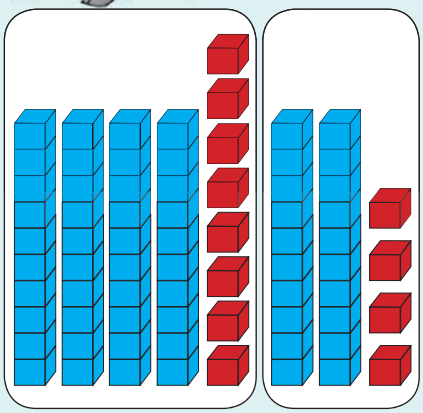

= 40 8 − 20 4

= 40 − 20 + 8 − 4

= □ − □

= □

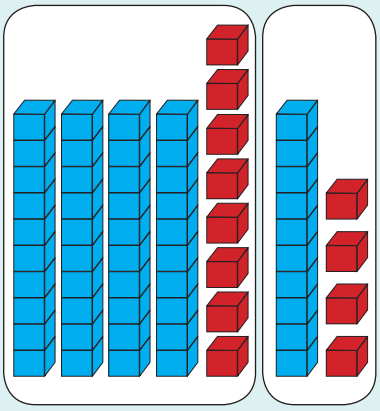

= □ □ − □ □

= □ − □ + □ − □

= □ − □

= □

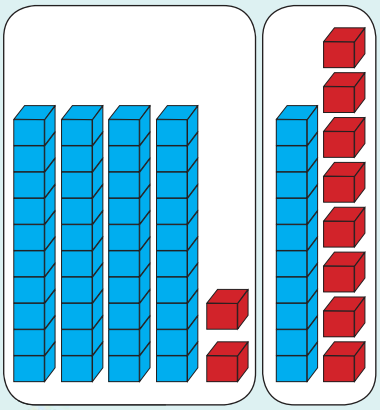

= □ □ − □ □

= □ − □ + □ − □

= □ − □

= □

Nginemali yephepha ema-R10, ne-R5 emumuwa kanye ne-R2 emumuwa ngebhangeni lami eliyifarigana. Nginemalini engiyibulungileko?

R20

R5

R2

R10

Ilanga:

Ukuhlanganisa okungaphezulu

Liyini inani/ithothali yebhlogo ngalinye?

1 10 5 10	2 10 6 20	3 20 5 20	4 20 4 10

Hlanganisa.

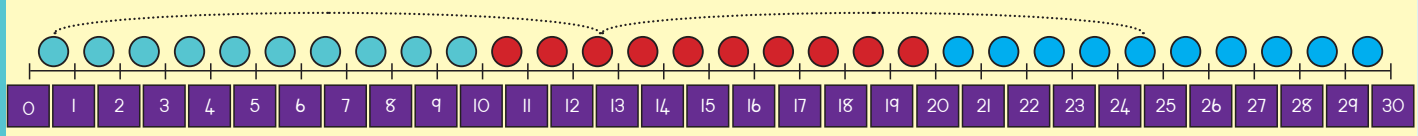

13 + 12 =

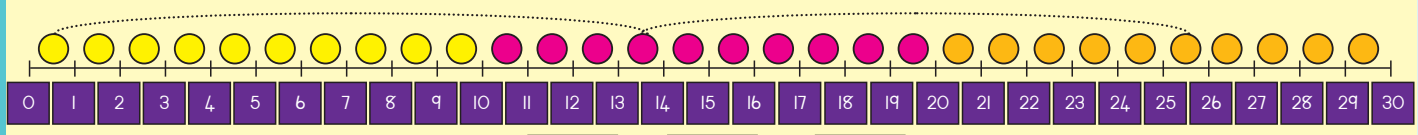

14 + 12 =

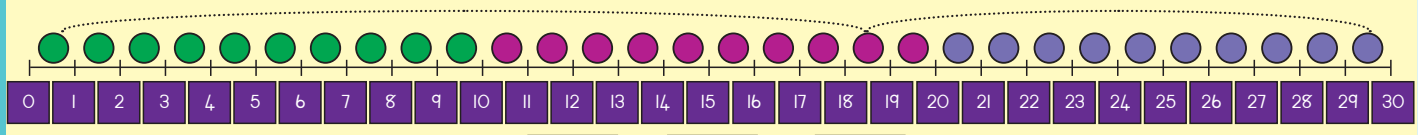

19 + 11 =

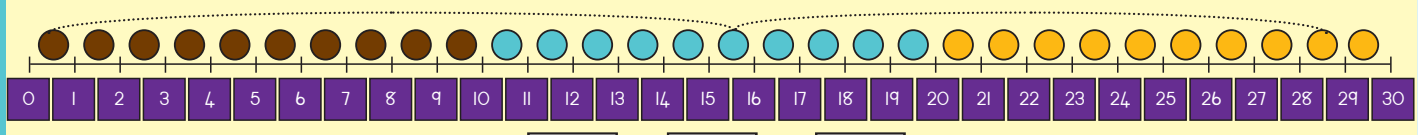

16 + 13 =

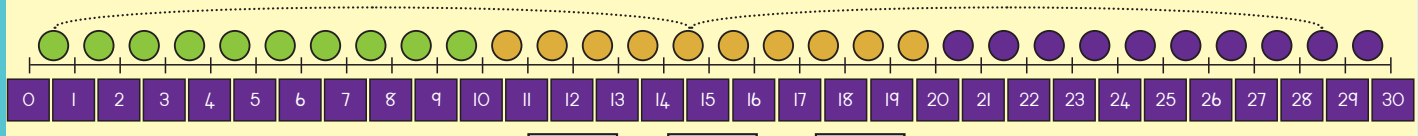

15 + 14 =





Hlanganisa.

12 + 11

= 10 2 + 10 1

= 10 + 10 + 2 + 1

= 20 + 3

= 23

13 + 15

= ☐ ☐ + ☐ ☐

= ☐ + ☐ + ☐ + ☐

= ☐ + ☐

= ☐

26 + 12

= ☐ ☐ + ☐ ☐

= ☐ + ☐ + ☐ + ☐

= ☐ + ☐

= ☐

23 + 22

= ☐ ☐ + ☐ ☐

= ☐ + ☐ + ☐ + ☐

= ☐ + ☐

= ☐

24 + 13

= ☐ ☐ + ☐ ☐

= ☐ + ☐

= ☐

35 + 12

= ☐ ☐ + ☐ ☐

= ☐ + ☐

= ☐

UBetty uthenge amaswidi abiza ama-R36, uSipho yena wathenga abiza ama-R13. Basebenzise malini emaswidini

Teacher:

Sign:

Date:

11 12 13 14 15 16 17 18 19 20

39b

Ilanga:

Ukuhlanganisa okungaphezulu (kuragela phambili)

1 Liyini inani/ithothali yebhlogo ngalinye?

12 + 10 = ☐

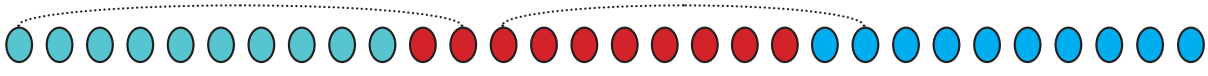

1 + 10 = ☐

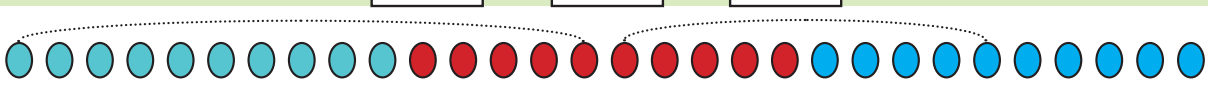

19 + 10 = ☐



2 Gwala woke umncamo oseleko bese uqedelela iimbalo.

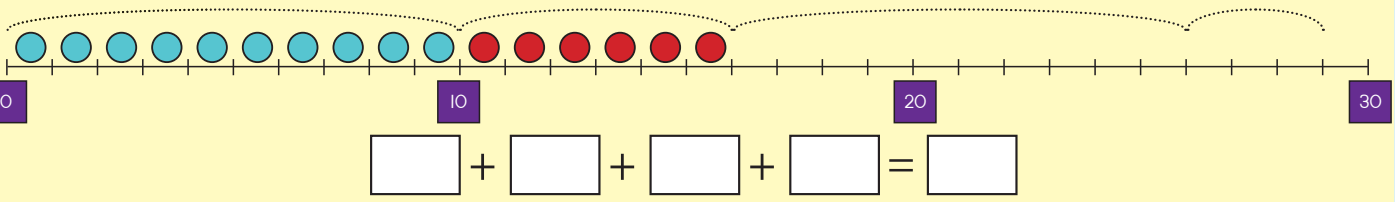

☐ + ☐ + ☐ + ☐ = ☐

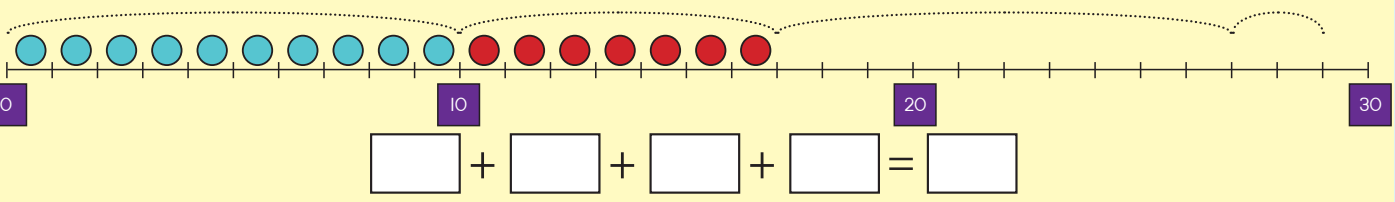

☐ + ☐ + ☐ + ☐ = ☐

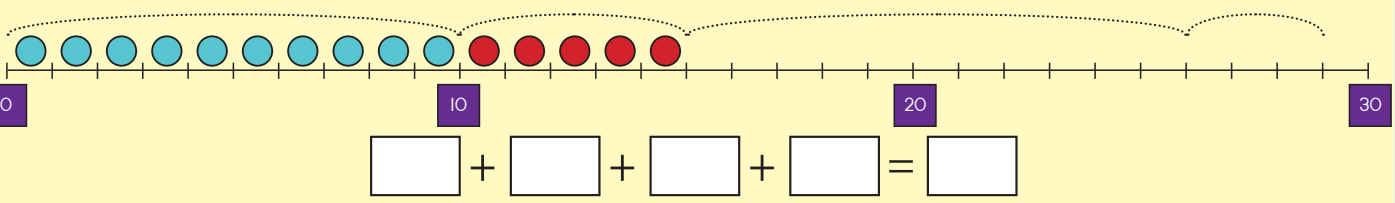

☐ + ☐ + ☐ + ☐ = ☐

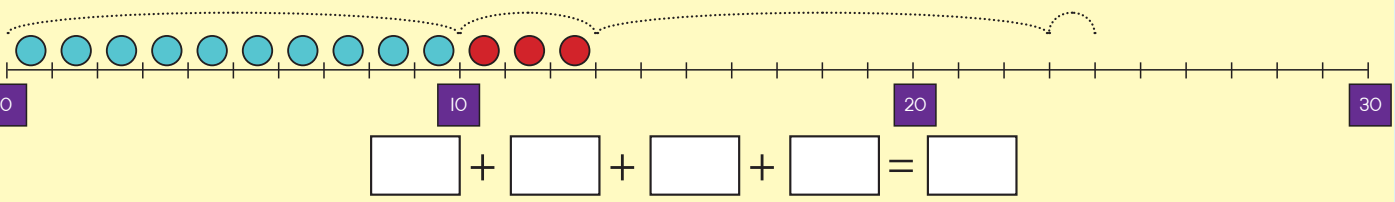

☐ + ☐ + ☐ + ☐ = ☐

1 2 3 4 5 6 7 8 9 10



Qedelela.

28	+	11	=	2	8	+	10	+	1	=	38	+	1	=	39
34	+	12	=	3	4	+	10	+	2	=		+		=	
23	+	13	=	2	3	+	10	+	3	=		+		=	
35	+	12	=	3	5	+	10	+	2	=		+		=	
26	+	11	=	2	6	+	10	+	1	=		+		=	

Hlanganisa:

11 + 10 =		23 + 10 =		36 + 10 =	
28 + 10 =		37 + 10 =		12 + 10 =	
34 + 10 =		29 + 10 =		15 + 10 =	

Isibalo se-7 nesesi-6 sili?

Gwala isithombe ukutjengisa ipendulo yakho.

Tlola isibalo samagama wakho ngokusebenzisa iinthombe.



Teacher:

Sign:

Date:

11 12 13 14 15 16 17 18 19 20

Ilanga:

Ubude



Faka ipendulo umbala ofana namabhlogo.

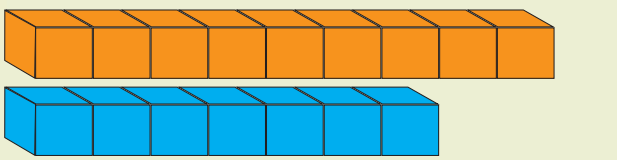

fitjhazana | ubude

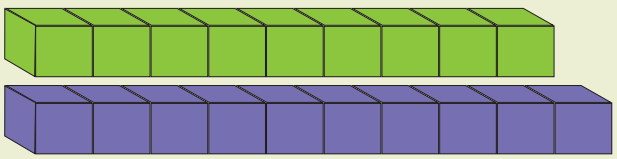

fitjhazana | ubude

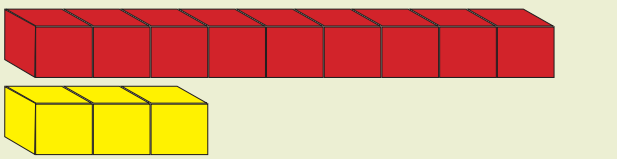

fitjhazana | ubude

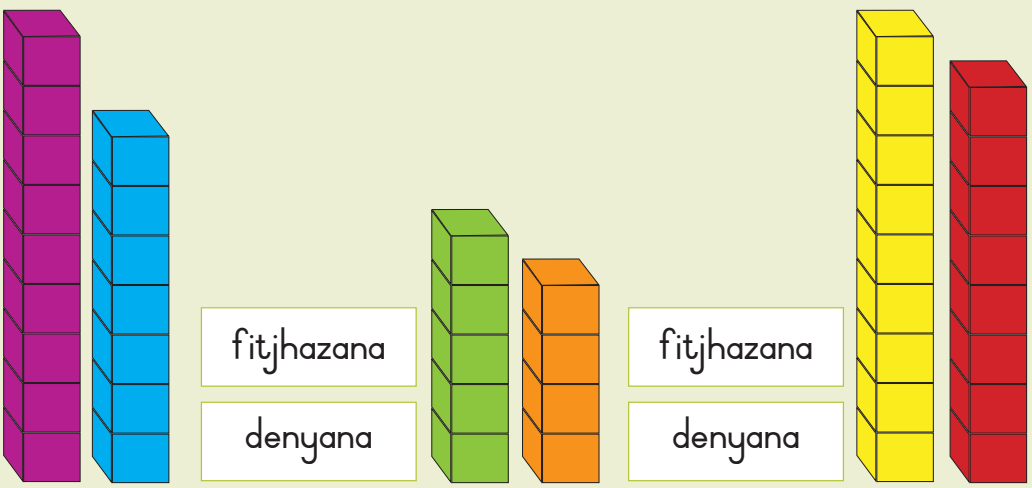

fitjhazana | fitjhazana | fitjhazana

denyana | denyana | denyana

Faka ipendulo umbala of ana namabhrugu amafitjhani womsana.



fitjhazana | denyana



denyana | fitjhazana



fitjhazana | denyana

Meda amahlangothi wekundla yokudlalela ngesandla nangenyawo kuSika I. Ikundla yokudlalela yide ngezandla ezingaki. Ikundla yokudlalela yide ngeenyawo ezingaki.

Ubude bebala bungaba zizandla ezingaki?

Ubude bebala bungaba ziinyawo ezingaki?

ubude



Teacher:

Sign:

Date:

11 12 13 14 15 16 17 18 19 20

Ilanga:

Ukukhupha (kuragela phambili)



Madanisa amakarada.

10 22	10 88	10 77	10 55	10 33
17 – 7 = 10	12 – 2 = 10	15 – 5 = 10	13 – 3 = 10	18 – 8 = 10



Sebenzisa inambalayini. Tlola isibalo sokukhupha.

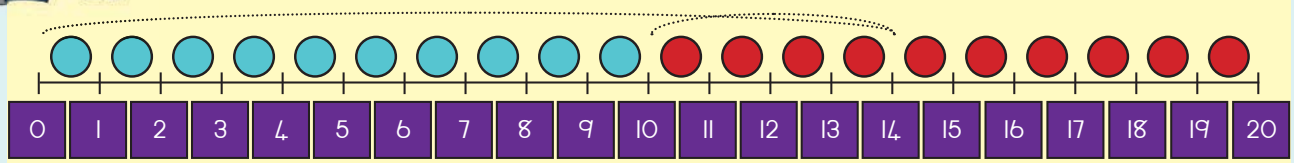

14 – 4 = 10

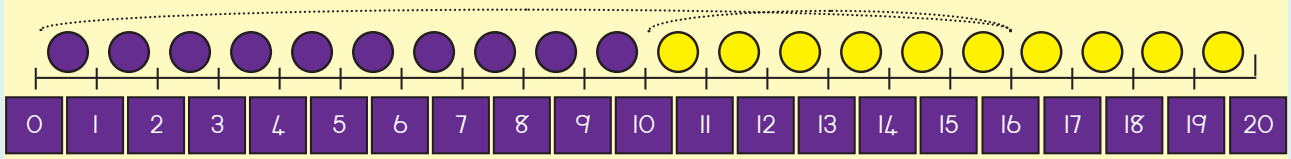

__ – __ = __

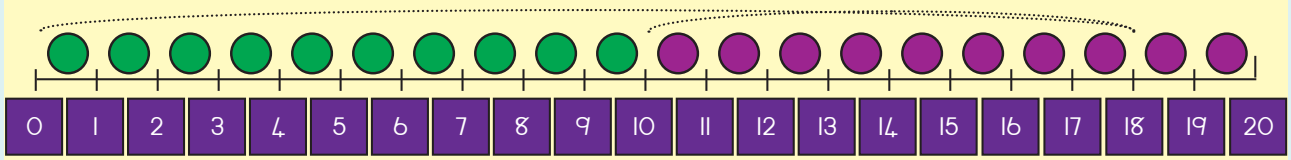

__ – __ = __

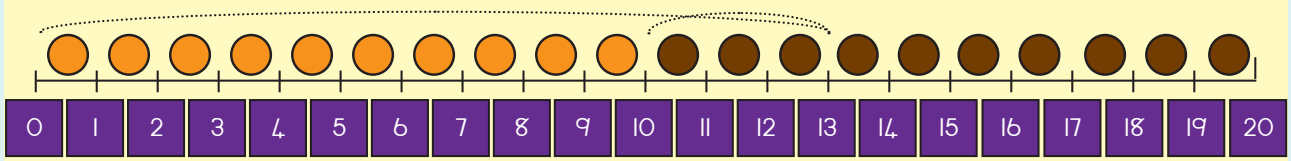

__ – __ = __







Ukukhupha.

10	3	−	3	=			
10	5	−	5	=			
10	1	−	1	=			
10	4	−	4	=			
10	9	−	9	=			

10	2	−	2	=			
10	7	−	7	=			
10	6	−	6	=			
10	8	−	8	=			
10	9	−	5	=			



Ukukhupha.

16 − 13

10	10						
6	3	=	3				
16	−	13	=	3			

14 − 12

10	10						
4	2	=					
14	−	12	=				

27 − 11

20	10						
7	1	=					
	−		=				

35 − 13

30	10						
5	3	=					
	−		=				

26 − 12

20	10						
6	2	=					
	−		=				

48 − 11

40	10						
8	1	=					
	−		=				



ULisa uneembalisi ezili-17. Ulahlekelwa ziimbalisi ezibu-8.



Usele neembalisi ezingaki?

Teacher:

Sign:

Date:



Ilanga:

Ukukhupha

Khupha iinomboro ezingenzasi kezingehla.

10 − 7 = 17	20 − 2 =	30 − 8 =	40 − 9 =
10 − 5 = 15	10 − 1 =	10 − 5 =	10 − 4 =
2 =	=	=	=

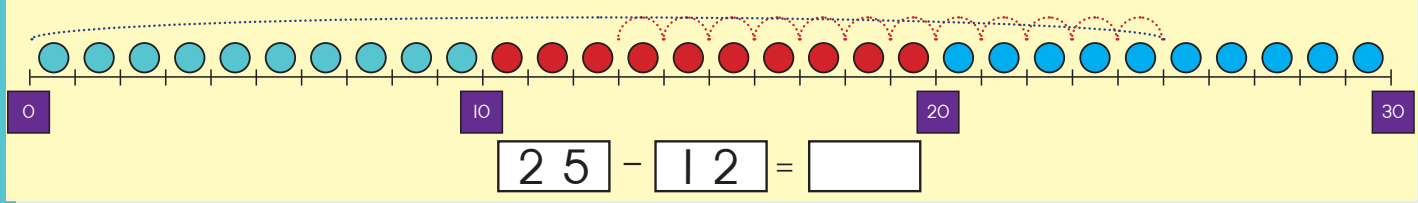

25 − 12 = ☐

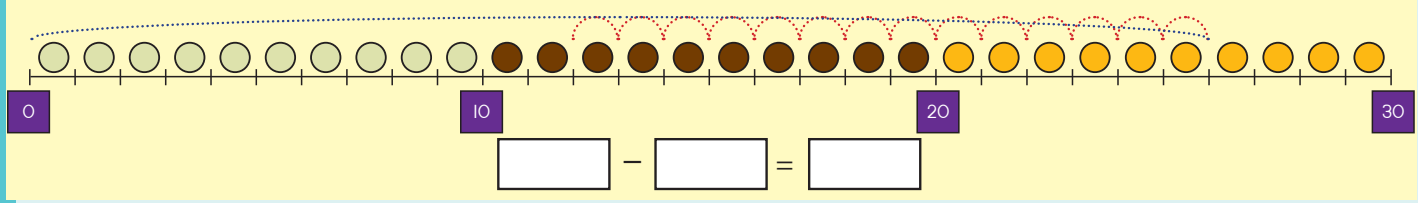

☐ − ☐ = ☐

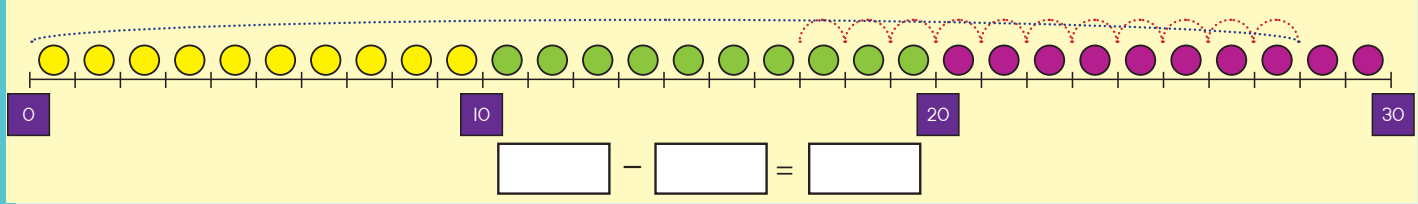

☐ − ☐ = ☐

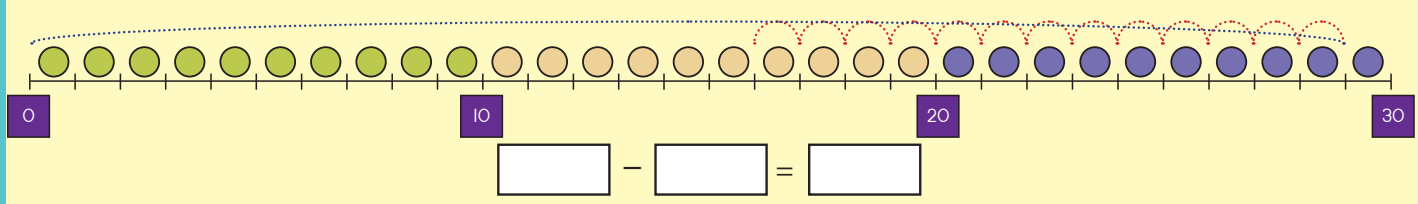

☐ − ☐ = ☐

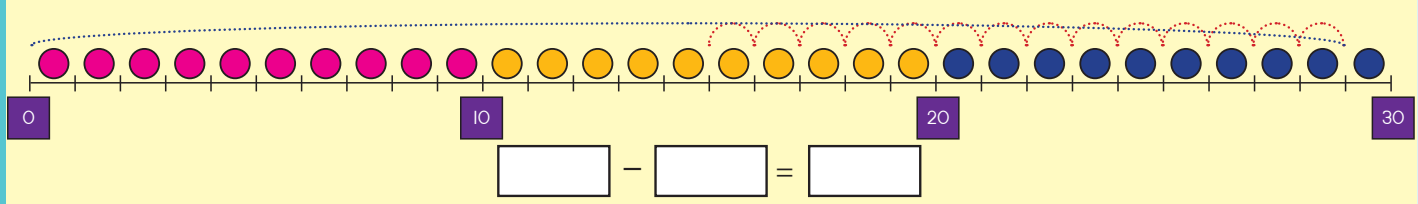

☐ − ☐ = ☐

1 2 3 4 5 6 7 8 9 10





Khupha.

45 – 23

= 40 [ ] – 20 3

= 40 – 20 + 5 – 3

= 20 + 2

= 22

38 – 16

= [ ] [ ] – [ ] [ ]

= [ ] – [ ] + [ ] – [ ]

= [ ] + [ ]

= [ ]

29 – 14

= [ ] [ ] – [ ] [ ]

= [ ] – [ ] + [ ] – [ ]

= [ ] + [ ]

= [ ]

48 – 11

= [ ] [ ] – [ ] [ ]

= [ ] – [ ] + [ ] – [ ]

= [ ] + [ ]

= [ ]

35 – 23

= [ ] [ ] – [ ] [ ]

= [ ] – [ ] + [ ] – [ ]

= [ ] + [ ]

= [ ]

38 – 15

= [ ] [ ] – [ ] [ ]

= [ ] – [ ] + [ ] – [ ]

= [ ] + [ ]

= [ ]



Teacher:

Sign:

Date:



Ilanga:

Ukukhupha (kuragela phambili)



Liyini inani loke lebhlogo ngayinye?

22 − 10 = ☐



25 − 10 = ☐



29 − 10 = ☐





Qedelela iimbalo.

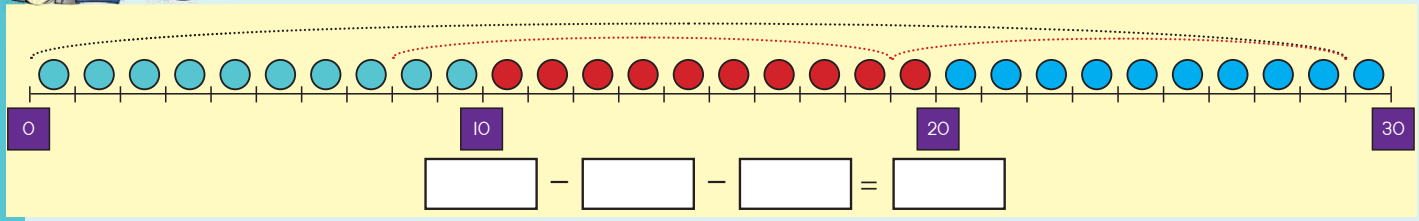

☐ − ☐ − ☐ = ☐

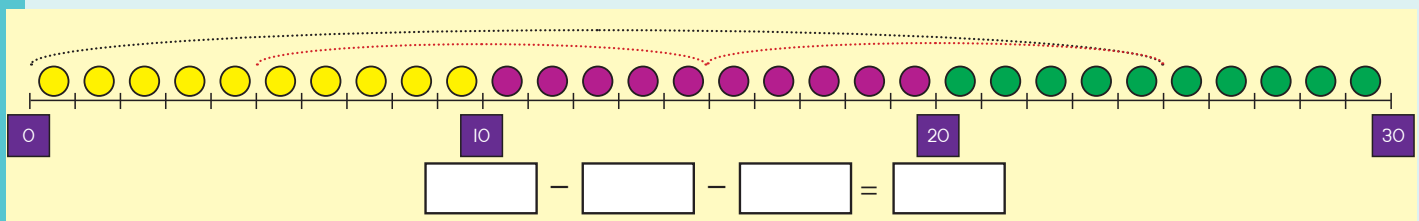

☐ − ☐ − ☐ = ☐

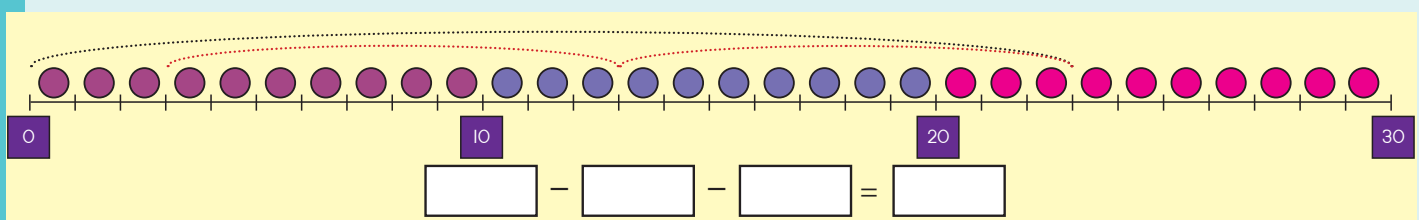

☐ − ☐ − ☐ = ☐

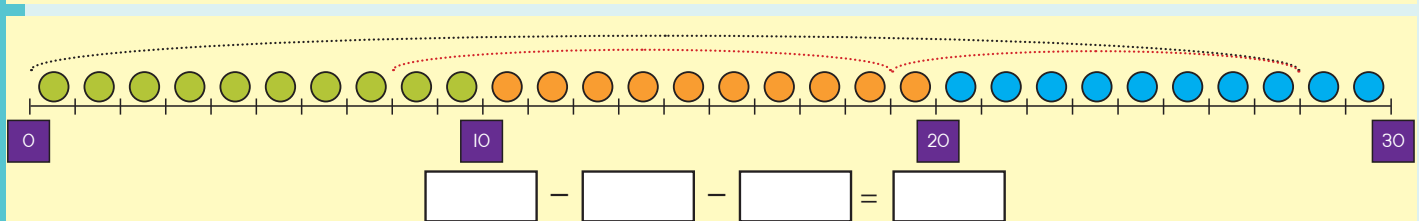

☐ − ☐ − ☐ = ☐







Qedelela.

46 − 13 =	38 − 14 =	25 − 11 =
49 − 23 =	27 − 16 =	46 − 32 =



Khupha.

21 − 10 =	43 − 10 =	16 − 10 =
28 − 10 =	27 − 10 =	22 − 10 =
34 − 10 =	37 − 10 =	45 − 10 =



Umehluko hlangana nama-35 nama-20 li?
Gwala isithombe ukutjengisa ipendulo yakho.

3 5 − 2 0 = _____



Tlola isibalo samagama wakho ngokusebenzisa iinthombe.

_____ − _____ = _____



Teacher:
Sign:
Date:



Ilanga:

Ubudisi nobululula

1 Qala iinthombe bese uphendula imibuzo.

Ngikuphi okululula kanye nalokho okubudisi khulu?



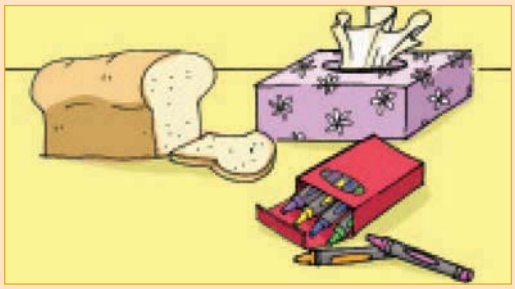

2 Namathisela nanyana ugwale iinthome zalokhu:

Iinthombe zezinto ezibudisi	Iinthombe zezinto ezilula



Umbala osarulani utjho kobala into ilula. Umbala ohlaza sasibhakabhaka utjho kobana into ibudisi. Tlola uthi Lula nanyana Budisi.

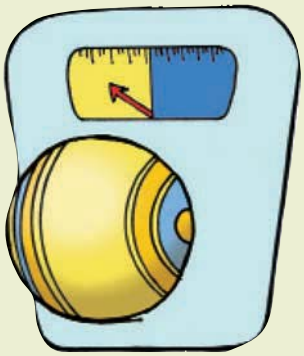

Lula













Namathisela nanyana ugwale ukuya ngalokho isikala/isimedo besikutjhoko.

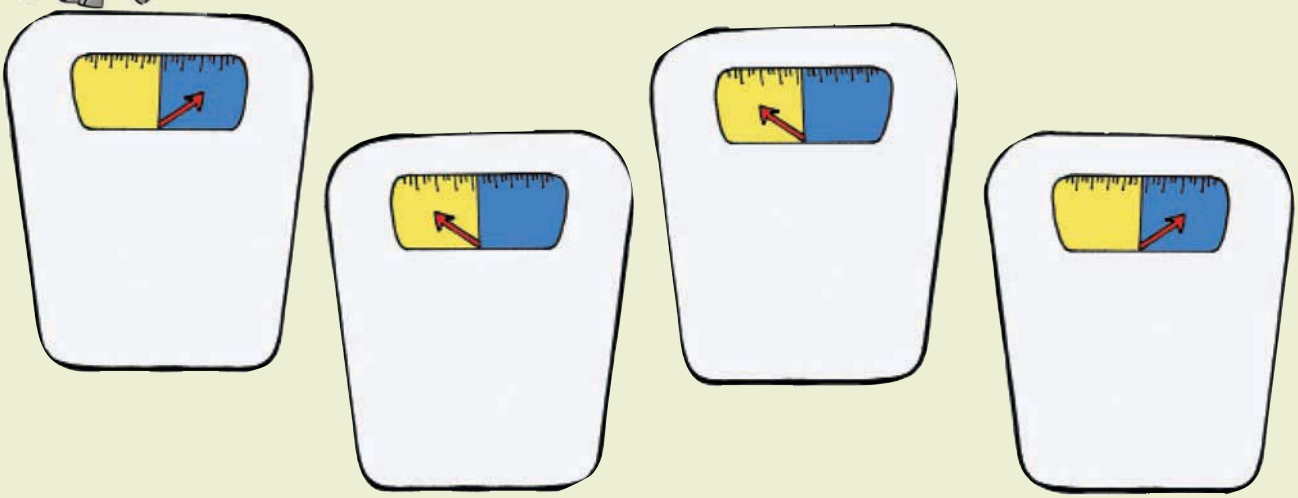



11 12 13 14 15 16 17 18 19 20

Teacher:

Sign:

Date:

Ilanga:

Isibalo samaphetheni: Ngamabili

1 Asibaleni ngakubili.





2 Gwala namkha namathisela iinthombe zezinto ezikhamba ngazimbili.

3 Sithome iphetheni. Wena-ke iqedelele.

1	2	3	4	5	6	7	8	9	10
11	12	13	14	15	16	17	18	19	20
21	22	23	24	25	26	27	28	29	30
31	32	33	34	35	36	37	38	39	40
41	42	43	44	45	46	47	48	49	50
51	52	53	54	55	56	57	58	59	60
61	62	63	64	65	66	67	68	69	70
71	72	73	74	75	76	77	78	79	80
81	82	83	84	85	86	87	88	89	90
91	92	93	94	95	96	97	98	99	100



Sebenzisa inambalayini ukutlola iphetheni.

0 1 2 3 4 5 6 7 8 9 10

2 4 6 8 10

10 11 12 13 14 15 16 17 18 19 20

20 21 22 23 24 25 26 27 28 29 30

0 1 2 3 4 5 6 7 8 9 10

Qedelela okulandelako.

2, 4, 6, __ , __ , __	13, 15, 17, __ , __ , __	26, 24, 22, __ , __ , __
62, 64, 66, __ , __ , __	55, 57, 59, __ , __ , __	9, 7, 5, __ , __ , __
44, 46, 48, __ , __ , __	10, 8, 6, __ , __ , __	29, 27, 25, __ , __ , __
1, 3, 5, __ , __ , __	98, 96, 94, __ , __ , __	95, 93, 91, __ , __ , __

2 4 6 8 80 12 14 16 18 20

Teacher:
Sign:
Date:

11 12 13 14 15 16 17 18 19 20

Ilanga:

Buyelela kabili

Qala ethebuleni yokuthoma neyesibili. Kwenzekeni?





Hlanganisa amacaphazi begodu utlole isibalo sawo.

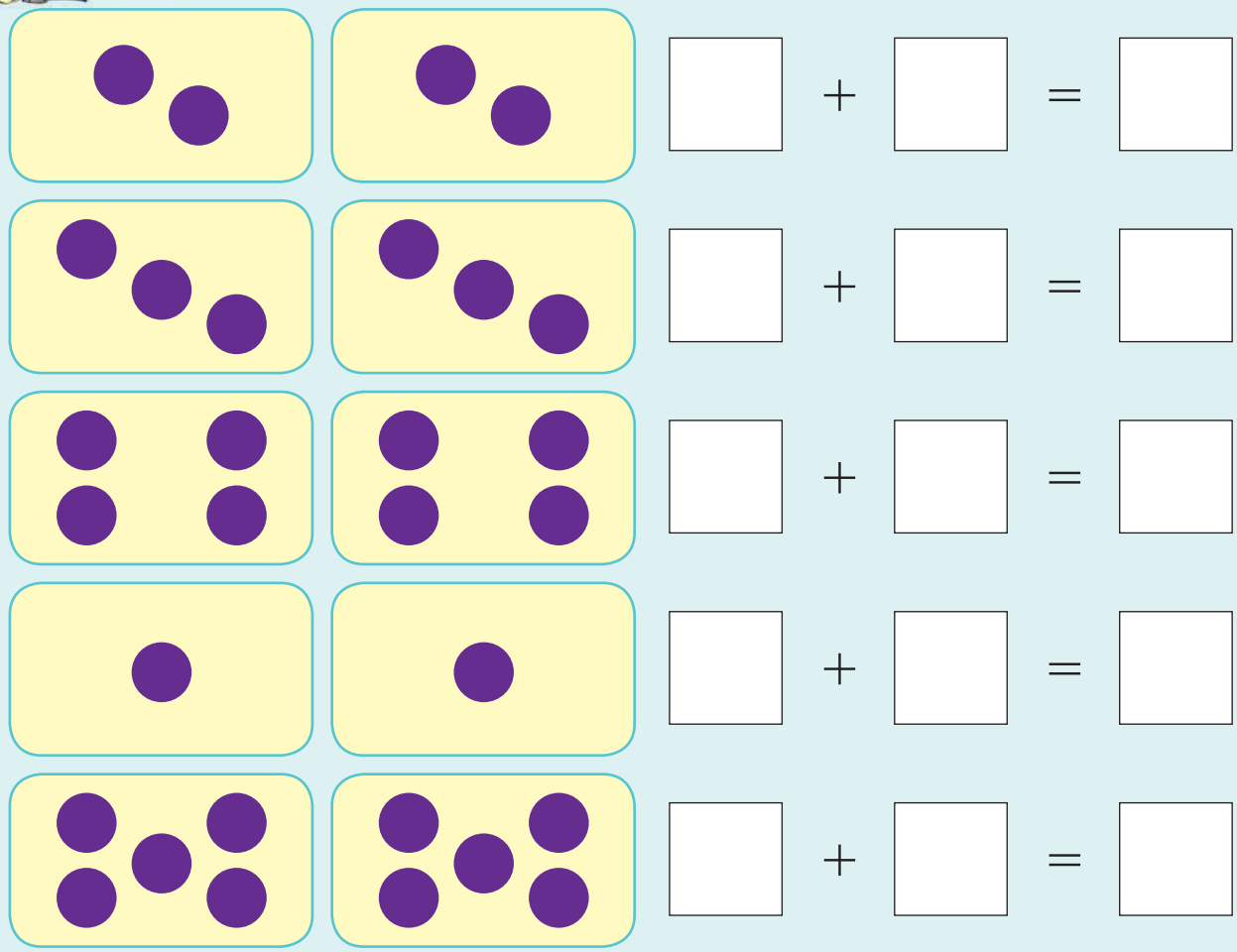



Sebenzisa inambalayini ukutlola isibalo.

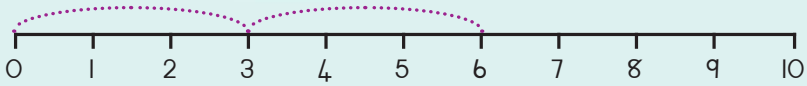

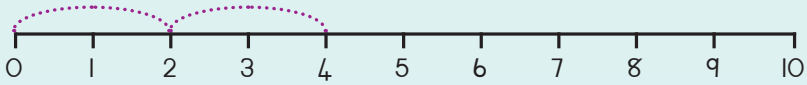

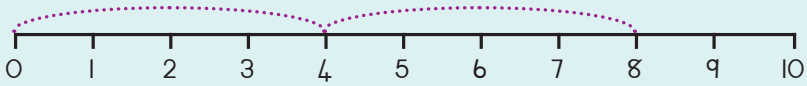

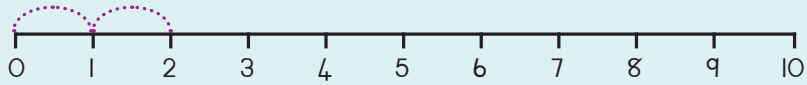

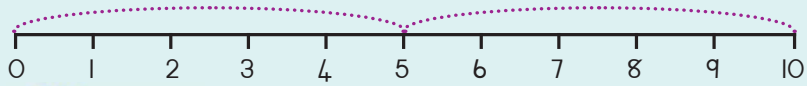

$\square + \square = \square$

$\square + \square = \square$

$\square + \square = \square$

$\square + \square = \square$

$\square + \square = \square$

Buyelela kabili okulandelako.

Buyelela kabili ngabo-1	1 + 1 = 2	2 × 1 = 2
Buyelela kabili ngabo-2	□ + □ = □	2 × □ = □
Buyelela kabili ngabo-3	□ + □ = □	2 × □ = □
Buyelela kabili ngabo-4	□ + □ = □	2 × □ = □
Buyelela kabili ngabo-5	□ + □ = □	2 × □ = □

Nginama-R5. Umngani wami unenani elibuyelelweko. Umngani wami unamalini?

Teacher:
Sign:
Date:

Ilanga:

Ngokuphindwe kabili

Qala ethebuleni lokuthoma nelesibili. Kwenzekani?



Hlanganisa amaqatjhazi, begodu utlole isibalo sawo ngalinye..

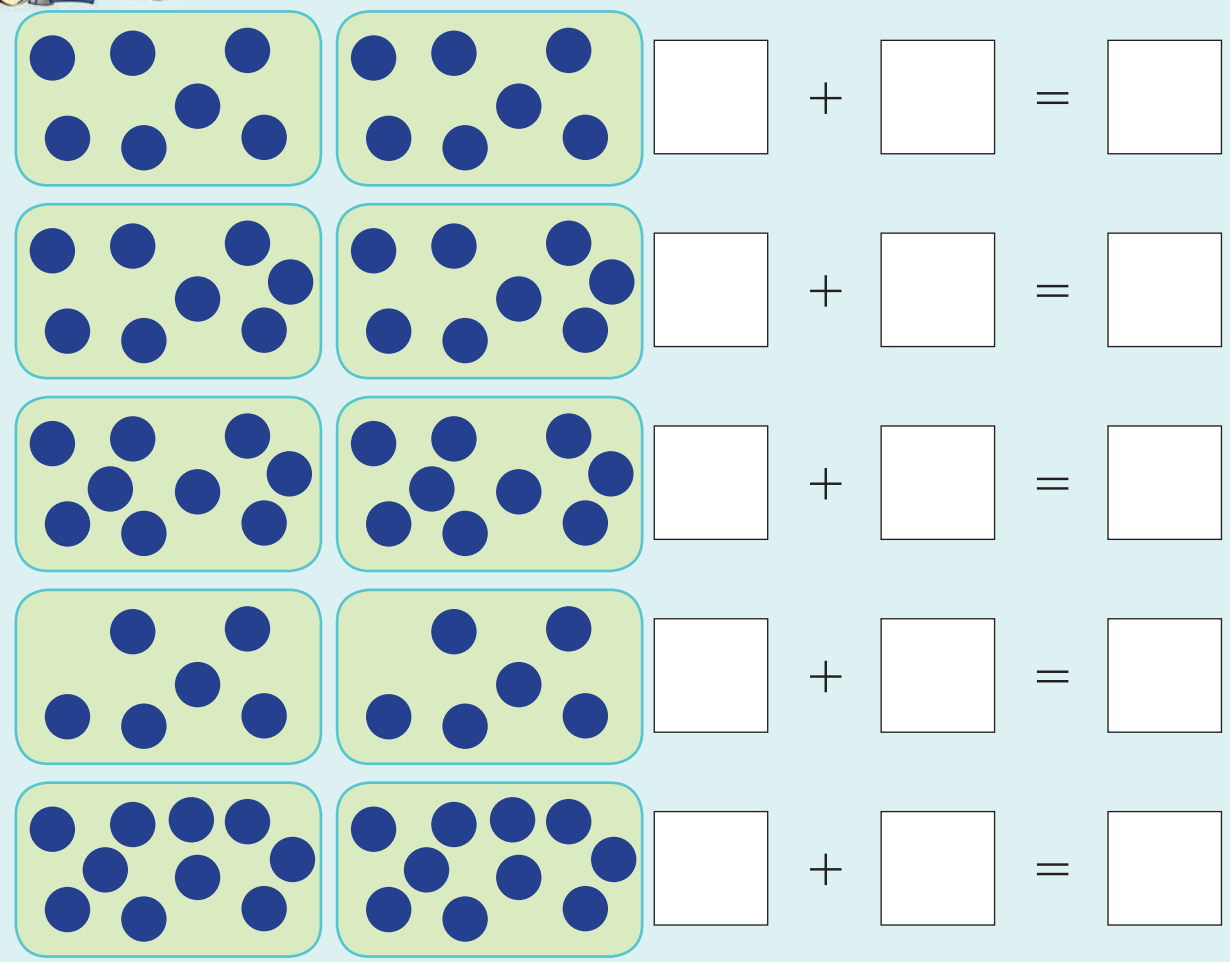



Sebenzisa inambalayini ukutlola isibalo.

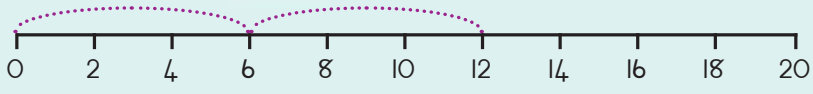

□ + □ = □

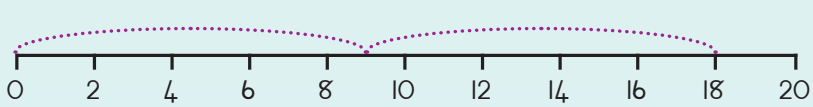

□ + □ = □



□ + □ = □

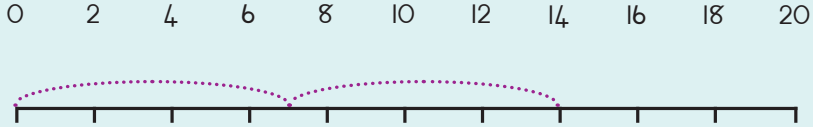

□ + □ = □

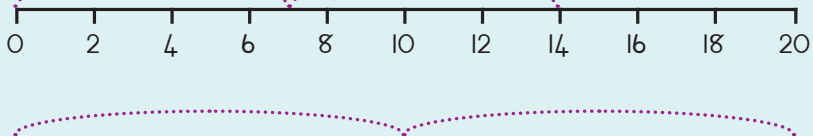

□ + □ = □

Buyelela kabili okulandelako.

Buyelela kabili ngabo-6	□ + □ = □	2 × 6 = 12
Buyelela kabili ngabo-7	□ + □ = □	2 × □ = □
Buyelela kabili ngabo-8	□ + □ = □	2 × □ = □
Buyelela kabili ngabo-9	□ + □ = □	2 × □ = □
Buyelela kabili ngabo-10	□ + □ = □	2 × □ = □

Umngani wami unamamabula ali-9. Mina nginenani elibuyelelweko lamamabula anawo. Nginamamabula amangaki?

Teacher:
Sign:
Date:



Ilanga:

Phinda kabili

Buyelela okubu-8 kabili.

1 2 3 4 5 6 7 8 1 2 3 4 5 6 7 8

1 2 3 4 5 6 7 8 9 10 11 12 13 14 15 16

Buyelela okuli-9 kabili.

1 2 3 4 5 6 7 8 9 1 2 3 4 5 6 7 8 9

1 2 3 4 5 6 7 8 9 10 11 12 13 14 15 16 17 18



Sebenzisa umncamo ukubuyelela iinomboro kabili. Yokuthoma sikuthomele yona.

Buyelela oku-5 kabili



5 + 5 = ☐

Buyelela oku-6 kabili



☐ + ☐ = ☐

Buyelela oku-7 kabili



☐ + ☐ = ☐

Buyelela okubu-8 kabili



☐ + ☐ = ☐

Buyelela okuli-9 kabili



☐ + ☐ = ☐





Buyelela iinomboro kabili. Faka umbala ngaphasi kwamabhlogo alitjhumi ukutjengisa ipendulo yakho.

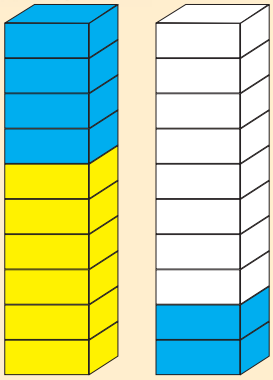

Buyelela kabili oku-6

6 + 6 = ☐

2 × 6 = ☐

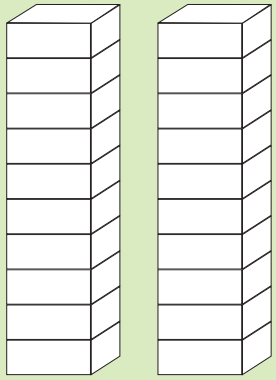

Buyelela kabili okubu-8

☐ + ☐ = ☐

2 × ☐ = ☐

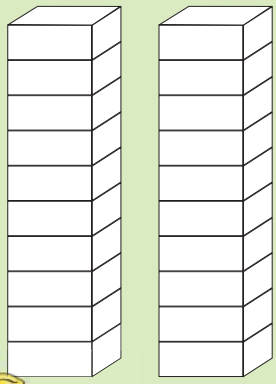

Buyelela kabili oku-7

☐ + ☐ = ☐

2 × ☐ = ☐

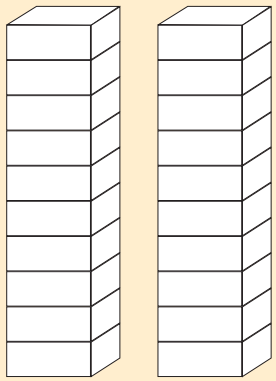

Buyelela kabili oku-9

☐ + ☐ = ☐

2 × ☐ = ☐

Buyelela kabili okulandelako:

Buyelela kabili okuli-7	☐ + ☐ = ☐	2 × ☐ = ☐
Buyelela kabili okuli-9	☐ + ☐ = ☐	2 × ☐ = ☐
Buyelela kabili okuli-6	☐ + ☐ = ☐	2 × ☐ = ☐
Buyelela kabili okubu-8	☐ + ☐ = ☐	2 × ☐ = ☐
Buyelela kabili okuli-10	☐ + ☐ = ☐	2 × ☐ = ☐

Nginamaphuzu abu-8. Umngani wami unenani elibuyelelweko lamaphuzu enginawo. Umnganami unamaphuzu amangaki?

Teacher:

Sign:

Date:



Ilanga:

Ukuphinda okubuyelelweko

Buyelela kabili okuli-12

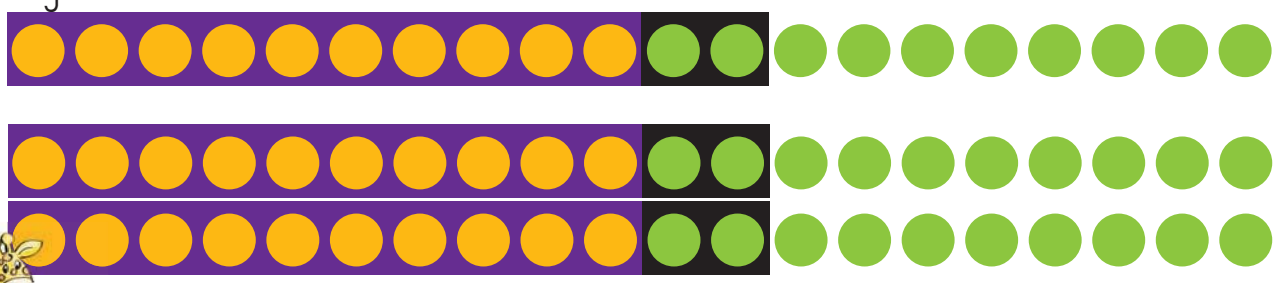



Sebenzisa umncamo ukubuyelela iinomboro kabili. Yokuthoma sesikuthomele yona.

Buyelela kabili okuli-13

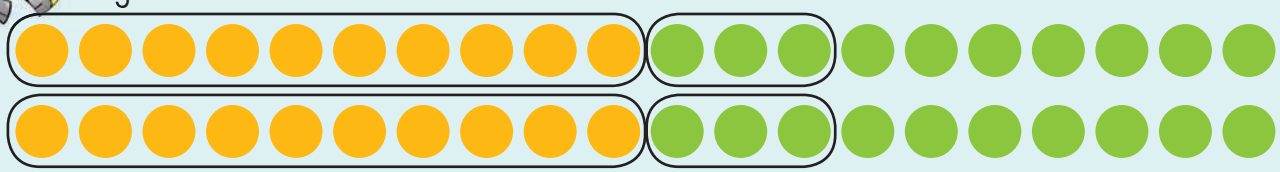

Buyelela kabili okuli-15 ☐ + ☐ = ☐

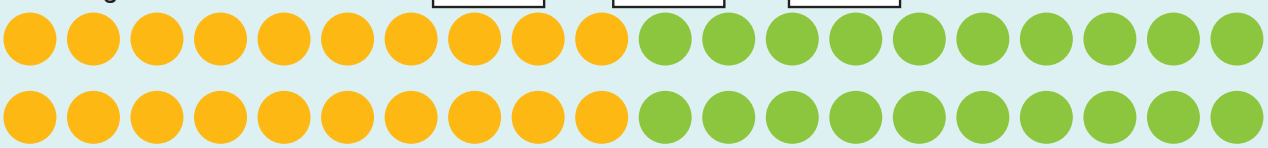

Buyelela kabili okuli-14 ☐ + ☐ = ☐



Buyelela kabili okuli-11 ☐ + ☐ = ☐



Buyelela kabili okuli-16 ☐ + ☐ = ☐



☐ + ☐ = ☐





Buyelela iinomboro. Faka ilingaphasi lamabhlogo alitjhumi umbala ukutjengisa ipendulo yakho.

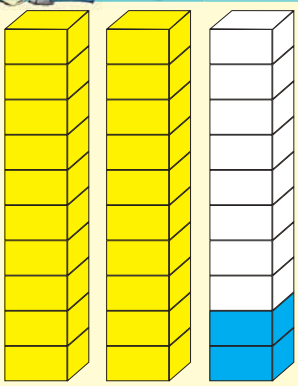

Buyelela kabili okuli-11

11	+	11	=		
2	×	11	=		



Buyelela kabili okuli-13

	+		=		
2	×		=		

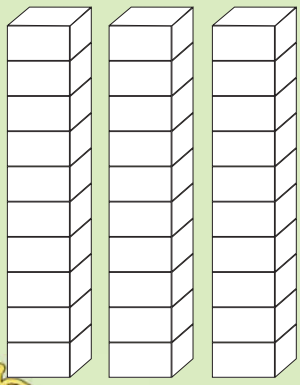

Buyelela kabili okuli-14

	+		=		
2	×		=		

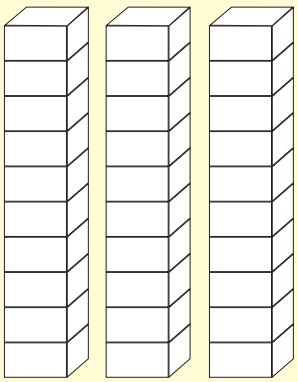

Buyelela kabili okuli-15

	+		=		
2	×		=		

Buyelela kabili okulandelako:

Buyelela kabili okuli-11		+		=		2	×		=	
Buyelela kabili okuli-13		+		=			×		=	
Buyelela kabili oku-16		+		=		2	×		=	
Buyelela kabili okuli-17		+		=			×		=	
Buyelela kabili okuli-18		+		=		2	×		=	

Ngidle amabhiskiti ali-14 ephalisanweni lokudla amabhiskiti. Othumbileko udle amabhiskiti alinani elibuyelelweko kilawo engiwadlileko. Othumbileko udle amabhiskiti amangaki?

Teacher:
Sign:
Date:



Ilanga:

Iimumathi kanye nomthamo

1 Khulumani ngeemumathi ezikelinye nelinye ideske.



2 Yitjho nangabe isimumathi sizele nanyana asinalitho.



Khalara amanzi ngaphakathi kweemumathi lezi.

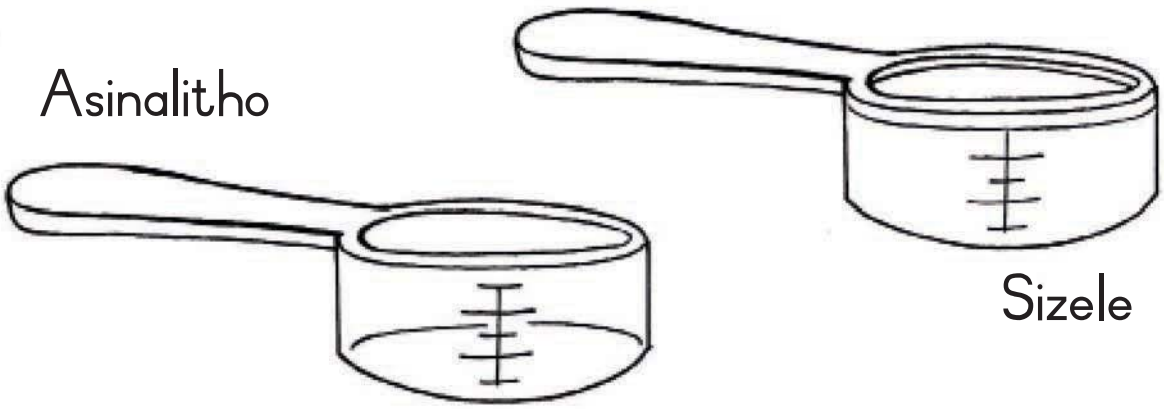

Gwala iimumathi ekungezakho bese ukhalara okungaphakathi.

Asinalitho	Sizele
Asinalitho	Sizele

Teacher:
Sign:
Date:

Ilanga:

Ukubuyabuyelela x 3

1 Mangaki amaswidi asetheyibuleni ngayinye?

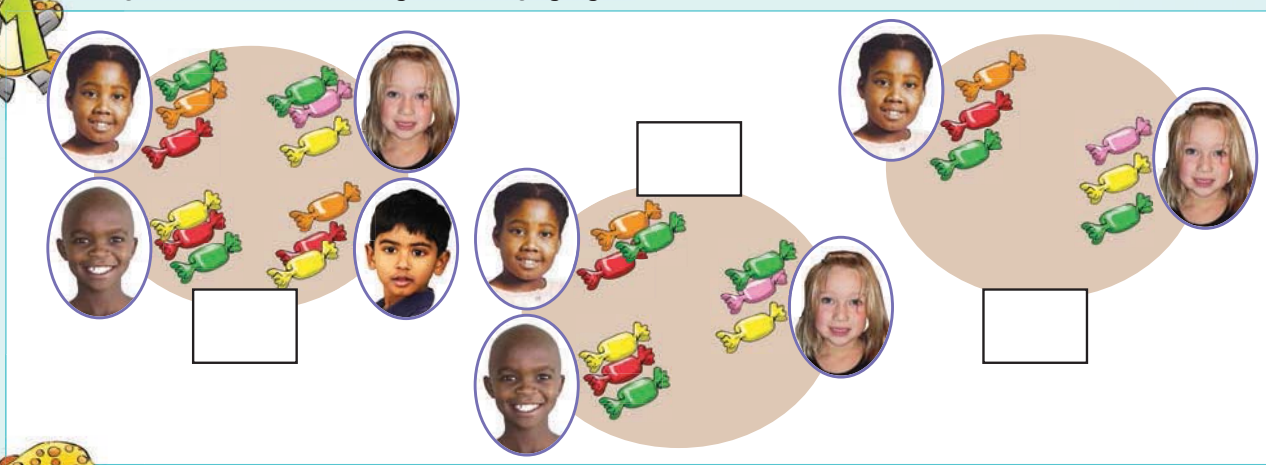

2 Qedelela okulandelako.

iinqhema ezi-2 zangaku-3	3 + 3 =	3 × 2 =
iinqhema-3 zangaku of 3	3 + 3 + 3 =	3 × 3 =
iinqhema ezi-4 zangaku-3	3 + 3 + 3 + 3 =	3 × 4 =
iinqhema ezi-6 zangaku-3	3 + 3 + 3 + 3 + 3 + 3 =	3 × 6 =
iinqhema ezili-7 zangaku-3	3 + 3 + 3 + 3 + 3 + 3 + 3 =	3 × 7 =

3

iinqhema ezi-3 zangaku-3	iinqhema ezi-4 zangaku-3	iinqhema ezi-5 zangaku-3



Gwala umgwalo wokulandelako.

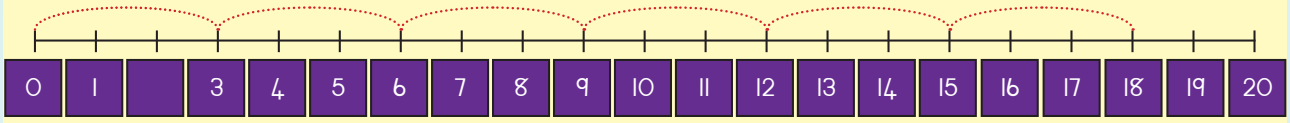

3, 6, 9, 12, ___ , ___

3 + 3 + 3 + 3 + 3 + 3 = ☐

6 × 3 = ☐

Umgwalo

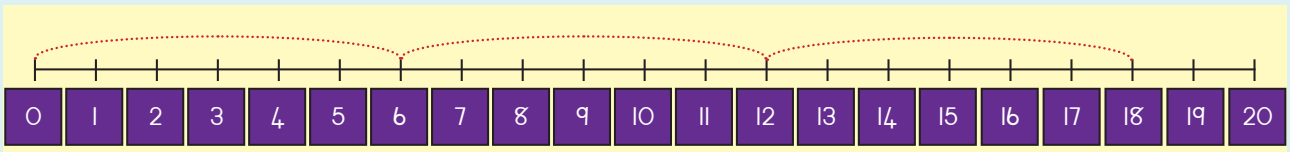

6, ___ , ___

6 + ☐ + ☐ = ☐

3 × ☐ = ☐

Umgwalo



Ipoto yokupheka inemilenze emithathu. Iimpoto ezili-7 zokupheka zinemilenze emingaki?

☐





3 6 9 12 15 18

21 24 27 30 33

Teacher:

Sign:

Date:



Ilanga: _____

Isibalo samaphetheni: Ngamabili

1 Asibaleni ngakubili.





2 Gwala namkha namathisela iinthombe zezinto ezikhamba ngambili.

3 Sithome iphetheni. Wena-ke iqedelele.

1	2	3	4	5	6	7	8	9	10
11	12	13	14	15	16	17	18	19	20
21	22	23	24	25	26	27	28	29	30
31	32	33	34	35	36	37	38	39	40
41	42	43	44	45	46	47	48	49	50
51	52	53	54	55	56	57	58	59	60
61	62	63	64	65	66	67	68	69	70
71	72	73	74	75	76	77	78	79	80
81	82	83	84	85	86	87	88	89	90
91	92	93	94	95	96	97	98	99	100



Sebenzisa inambalayini ukutlola iphetheni.

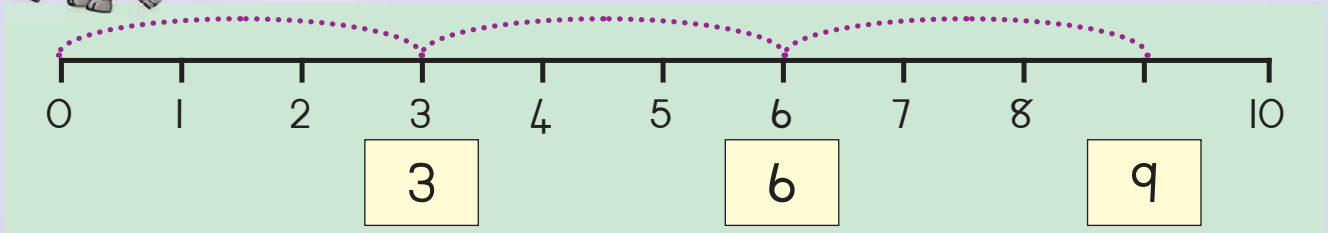

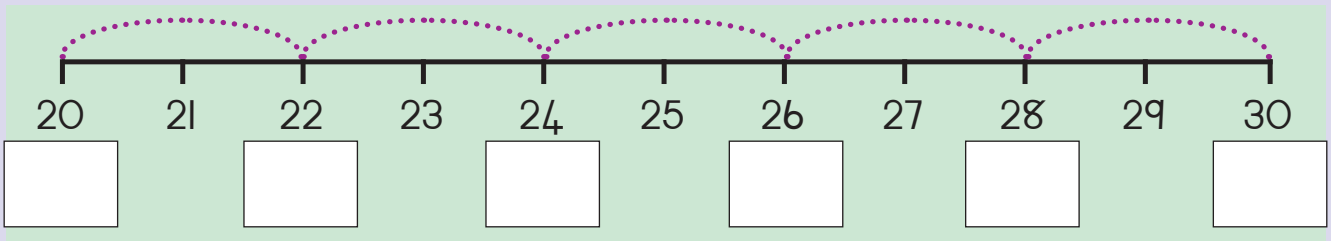

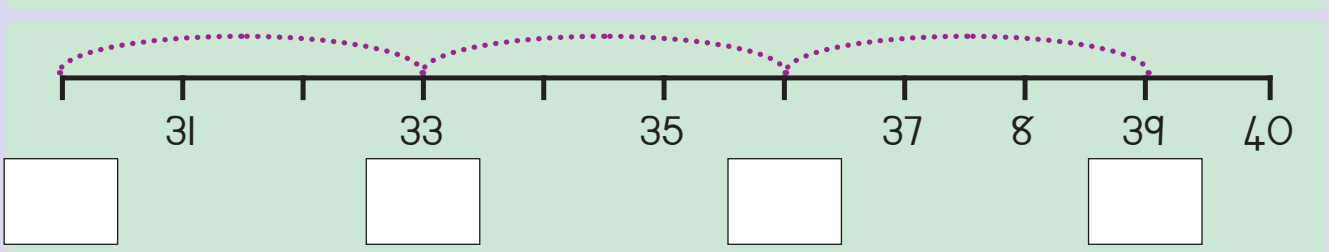

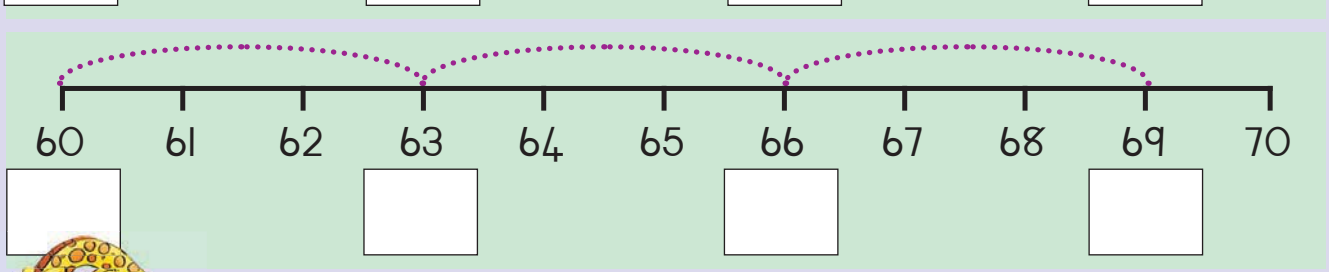



Qedelela okulandelako.

3, 6, 9, __ , __ , __	1, 4, 7, __ , __ , __	99, 96, 93, __ , __ , __
36, 39, 42, __ , __ , __	22, 25, 28, __ , __ , __	66, 63, 60, __ , __ , __
12, 15, 18, __ , __ , __	15, 12, 9, __ , __ , __	40, 37, 34, __ , __ , __



Kunamatrhayisekeli ali-10 esikolweni sabancani.
Mangaki amavilo weembhayisigili sele awoke?

Teacher:
Sign:
Date:



Ilanga:

Ukubuyabuyelela x 4

Mangaki amaswidi asetafuleni ngayinye?



Qedelela okulandelako.

iinqhema ezi-3 zangaku-4	4 + 4 + 4 =	3 × 4 = ☐
iinqhema ezi-2 zangaku-4	4 + 4 =	2 × 4 = ☐
iinqhema ezi-4 zangaku-4	4 + 4 + 4 + 4 =	4 × 4 = ☐
iinqhema ezi-6 zangaku-4	4 + 4 + 4 + ☐ + 4 + 4 =	6 × 4 = ☐
iinqhema ezi-7 zangaku-4	4 + 4 + 4 + 4 + 4 + 4 + 4 =	7 × 4 = ☐

Gwala umgwalo wokulandelako.

iinqhema ezi-3 zangaku-4	iinqhema ezi-4 zangaku-4	iinqhema ezi-5 zangaku-4

1 2 3 4 5 6 7 8 9 10



Gwala umgwalo wokulandelako.

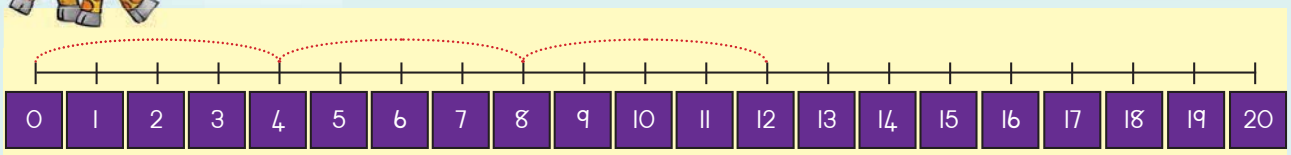

4, 8, ___

4 + 4 + 4 = ☐

4 × 3 = ☐

Umgwalo



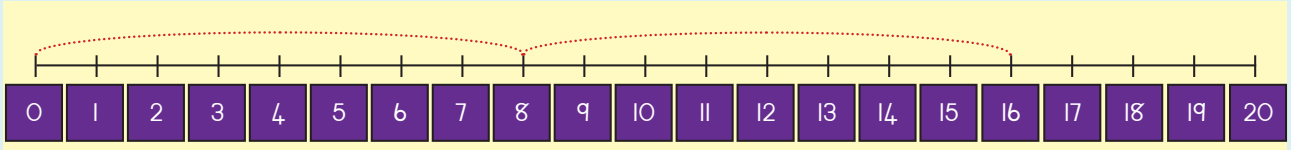

8, ___

8 + ☐ = ☐

8 × ☐ = ☐

Umgwalo



Ipera inemilenze emi-4. Iimpera ezintathu zinemilenze emingaki? ☐



4 8 12 16 20 24

28 32 36 40

Teacher:

Sign:

Date:



Ilanga: _____

Isibalo samaphetheni: Ngakune

1 Asibaleni ngakune.





2 Gwala namkha namathisela izinto ezikhamba ngazine.

3 Sithome iphetheni. Wena iqedelele.

1	2	3	4	5	6	7	8	9	10
11	12	13	14	15	16	17	18	19	20
21	22	23	24	25	26	27	28	29	30
31	32	33	34	35	36	37	38	39	40
41	42	43	44	45	46	47	48	49	50
51	52	53	54	55	56	57	58	59	60
61	62	63	64	65	66	67	68	69	70
71	72	73	74	75	76	77	78	79	80
81	82	83	84	85	86	87	88	89	90
91	92	93	94	95	96	97	98	99	100



Sebenzisa inambalayini ukutlola iphetheni.

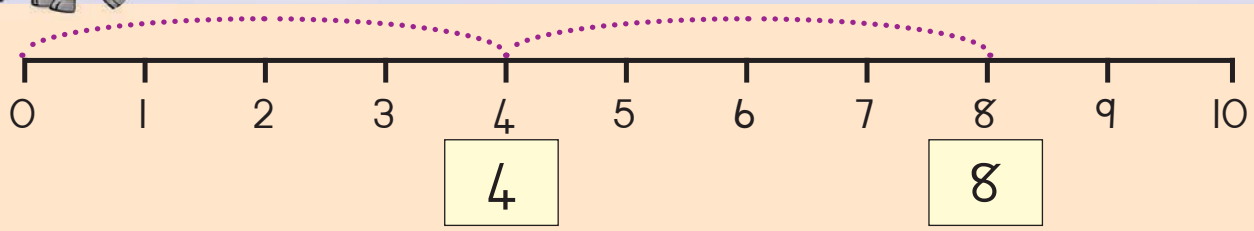

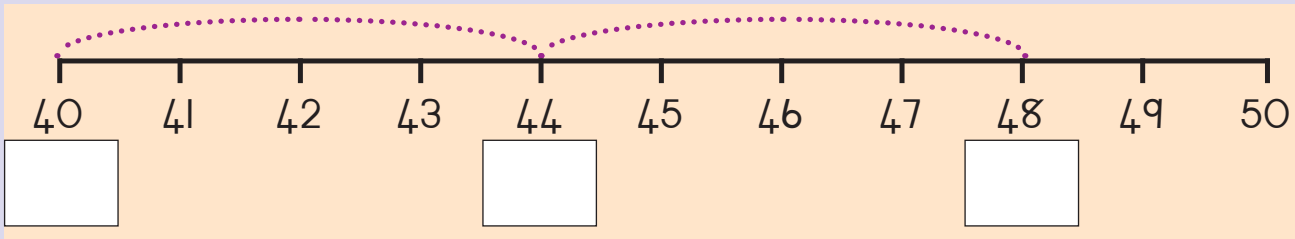

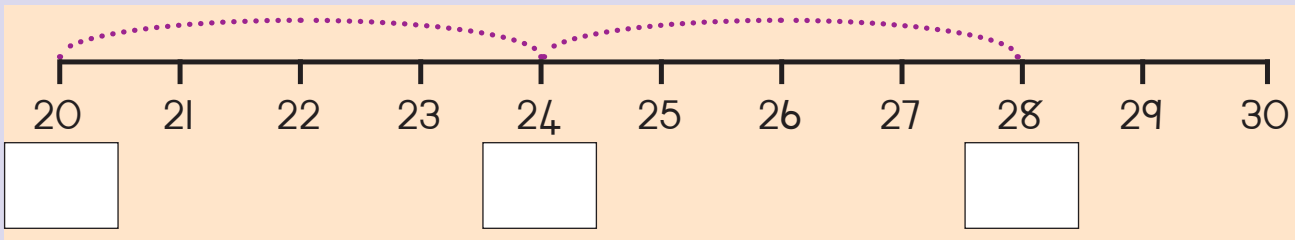

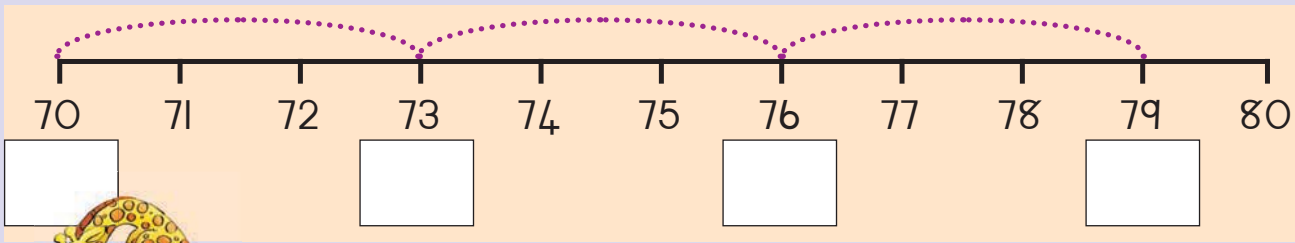

Qedelela okulandelako.

4, 8, 12, __ , __ , __	1, 5, 9, __ , __ , __	48, 44, 40, __ , __ , __
28, 32, 36, __ , __ , __	42, 46, 50, __ , __ , __	60, 56, 52, __ , __ , __
12, 16, 20, __ , __ , __	20, 16, 12, __ , __ , __	70, 66, 62, __ , __ , __

Kunamabhiskiti amane ngephaketheni. Ngithengise amaphakethe wamabhiskiti ali-9. Ngithengise amabhiskiti amangaki?

Teacher:
Sign:
Date:



Ilanga:

Ukubuyabuyelela indatjana

Yenza indatjana yakho ngokusebenzisa amagama anjengamehlo, imilenze, isandla, iinyawo, iinlwana, abantu. Hlanganisa inomboro nenye.



Ukatsu unamehlo ama-2. Abokatsu aba-4 banamehlo amangaki?

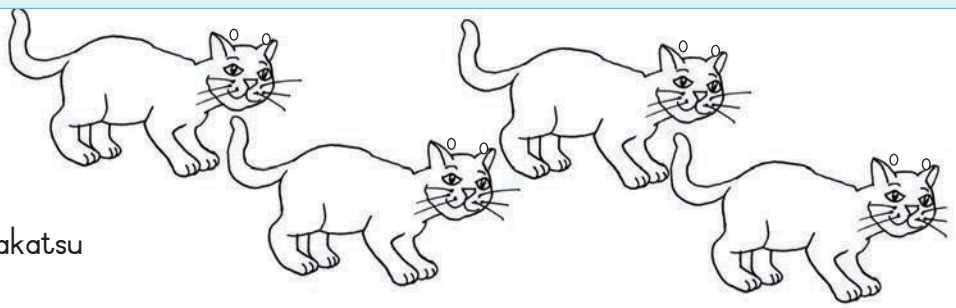

Faka amehlo kakatsu umbala.

Tjengisa lokho ngeembalisi.

Kutjengise kunambalayini.

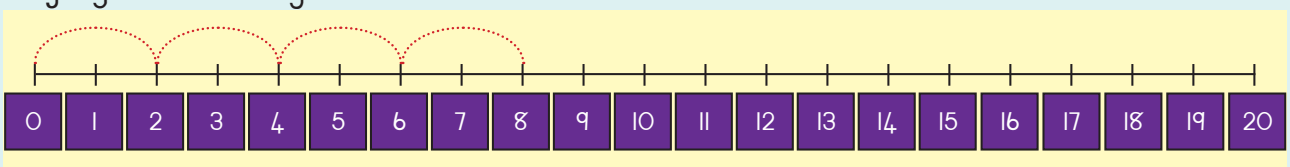

□ + □ + □ + □ = □

□ × □ = □





Ibhayisigili emavili-ntathu inamavili ama-3. Zinamavili amangaki iimbhayisigili ezihlanu ezimavili-ntathu?



Faka amavili webhayisigili emavili-ntathu umbala.

Tjengisa lokho ngeembalisi.

Kutjengise kunambalayini.

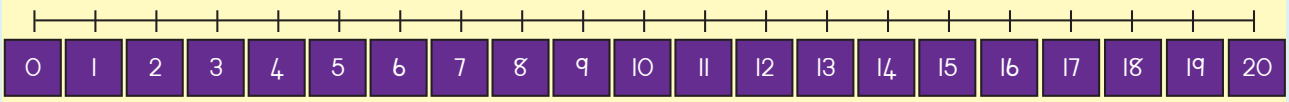

+ = × =

Inja inemilenze emi-4. Zinemilenze emingaki izinja ezi-4?

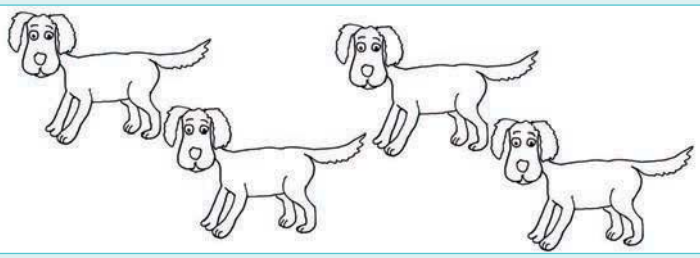

Faka imilenze yenja umbala.

Tjengisa lokho ngeembalisi.

Kutjengise kunambalayini.

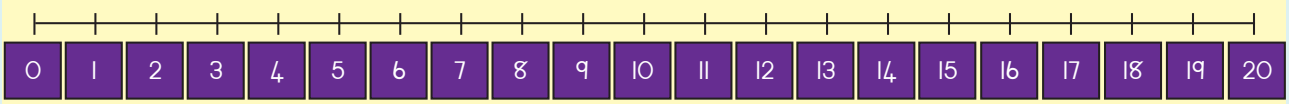

+ = × =

Teacher:
Sign:
Date:

Ilanga:

Ama-iri

1 Khulumani namawatjhi.



Umkhono omfitjhani usitjengisa ama-iri.
Lapha isitjengisa i-iri le-7.

Umkhono ukhamba uzombe iwatjhi, uzombe uzombe bewuzombe. Umkhono wewatjhi ukhamba uzombe bewuzombe, ukusitjela isikhathi.

2 Umkhono omfitjhani usitjengisa ini?



_____ i-iri

_____ ama-iri

_____ ama-iri

_____ ama-iri



_____ ama-iri

_____ ama-iri

_____ ama-iri

_____ ama-iri

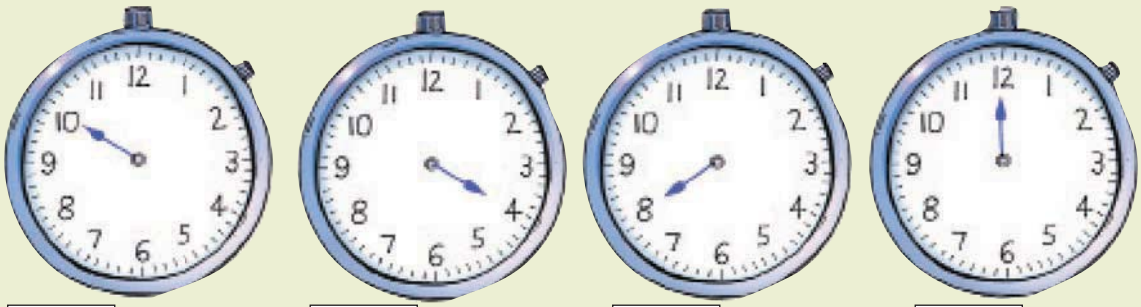

_____ ama-iri

_____ ama-iri

_____ ama-iri

_____ ama-iri

Gwala umkhono omfitjhani.

ama-iri ama 4



i-iri eli-1



ama-iri ama 11



ama-iri ama 7



ama-iri abu 9



ama-iri ali 10



ama-iri ama 2



ama-iri ama 5



ama-iri ama 3



ama-iri asi 6



ama-iri abu 8



ama-iri ali 12



Ngikuphi okungathatha i-iri? Faka umbala/Khalara endaweni enembako.



Ukwenza umsebenzi wesikolo



Ukulala



Ukuhlamba amazinyo

Teacher:

Sign:

Date:

11 12 13 14 15 16 17 18 19 20

Ilanga:

Isibalo samaphetheni: Ngakuhlanu

1 Asibaleni ngakuhlanu.





2 Gwala namkha namathisela iinthombe ezikhamba ngazihlanu.

3 Sithome iphetheni. Wena-ke iqedelele.

1	2	3	4	5	6	7	8	9	10
11	12	13	14	15	16	17	18	19	20
21	22	23	24	25	26	27	28	29	30
31	32	33	34	35	36	37	38	39	40
41	42	43	44	45	46	47	48	49	50
51	52	53	54	55	56	57	58	59	60
61	62	63	64	65	66	67	68	69	70
71	72	73	74	75	76	77	78	79	80
81	82	83	84	85	86	87	88	89	90
91	92	93	94	95	96	97	98	99	100



Sebenzisa inambalayini ukutlola iphetheni.

0 1 2 3 4 5 6 7 8 9 10

0 5 10

40 41 42 43 44 45 46 47 48 49 50

21 22 23 24 25 26 27 28 29 30 31

70 71 72 73 74 75 76 77 78 79 80

Qedelela okulandelako.

5, 10, 15, __ , __ , __	1, 6, 11, __ , __ , __	50, 45, 40, __ , __ , __
20, 25, 30, __ , __ , __	23, 28, 33, __ , __ , __	60, 55, 50, __ , __ , __
30, 35, 40, __ , __ , __	25, 20, 15, __ , __ , __	54, 49, 44, __ , __ , __

5 10 15 20 25 30 35 40 45 50

Teacher:
Sign:
Date:

11 12 13 14 15 16 17 18 19 20



Ilanga:

Imizuzu

1 Imida emifitjhani enzima ewatjhini isitjela ini?





Cabanga ngazozoke izinto ongazenza ngomzuzu owodwa.

2 Zalisa ngemizuzu.

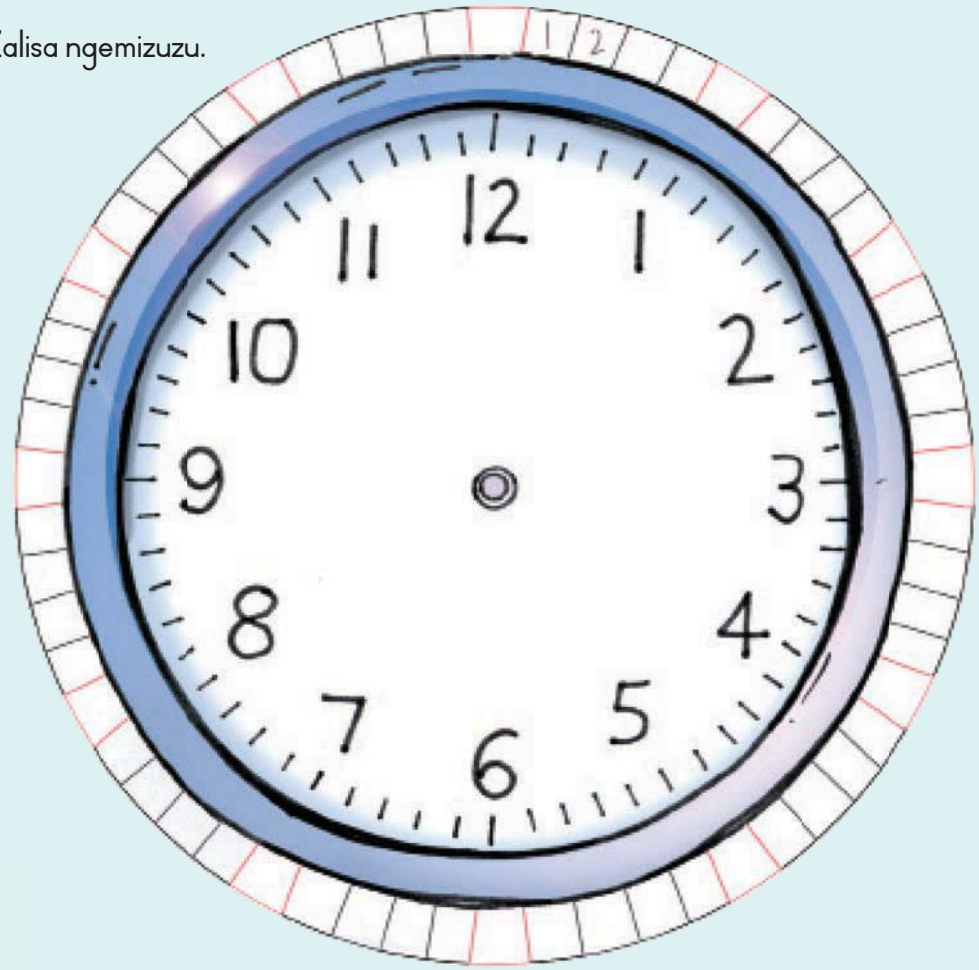

3 Tlola iinomboro lapha ngenzasi ngaphakathi kweenkwere ezibovu.





Gwala izinto ongazenza ngemizuzu elandelako:

Ngomzuzu owodwa - 1	Ngemizuzu emi - 5
Ngemizuzu ema - 30	Ngemizuzu ema - 60



Teacher:

Sign:

Date:



Ilanga: _____

Eminye imizuzu

1 Khulumani ngewatjhi.



Umkhono omude usitjengisa imizuzu.
Lappha etjengisa imizuzu ei-10.

Umkhono ukhamba uzombe iwatjhi, uzombe uzombe bewuzombe.
Umkhono wewatjhi ukhamba uzombe bewuzombe, ukusitjela isikhathi.

2 Umkhono omude usutjengisa ini?

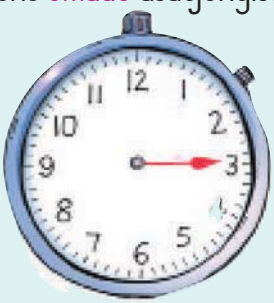

_____ imizuzu



_____ imizuzu



_____ imizuzu



_____ imizuzu



_____ imizuzu



_____ imizuzu

Gwala umkhono omude.

imizuzu ema-55



imizuzu ema-35



imizuzu ema-60



imizuzu eli-10



imizuzu ema-45



imizuzu eli-12



Ngikuphi okungathatha umzuzu owodwa? Faka umbala/Khalara ependulweni enembako.



Ukweqa



Ukudlala



Ukudla

Teacher:

Sign:

Date:

Ilanga:

Ukuqhema nokwabelana

1 Mabhlogo amangaki endulungeni ngayinye hlangana nabentwana?



2 Mangaki amabhlogo asendulungeni ngayinye? Tlola inani elihlangeneko, inani ngendulungeni ehlaza kwesibhakabhaka.

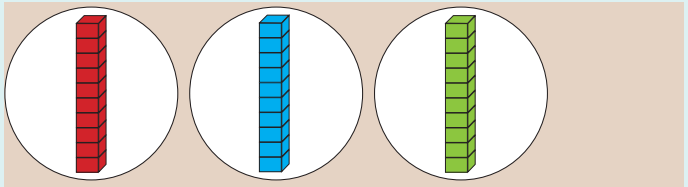

□ × □ = □

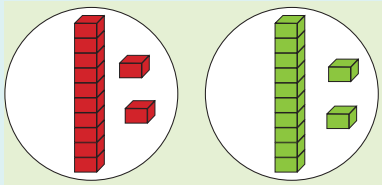

□ × □ = □

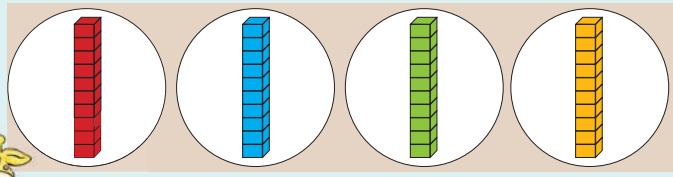

□ × □ = □

3 Yaba amabhlogo hlangana neendulungu.

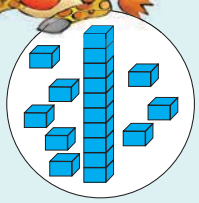

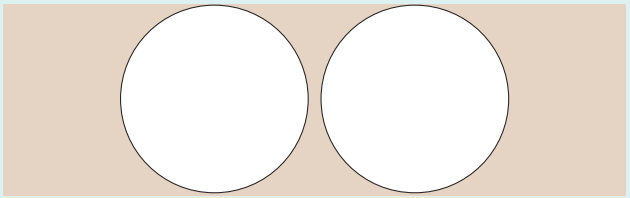

□ ÷ □ = □



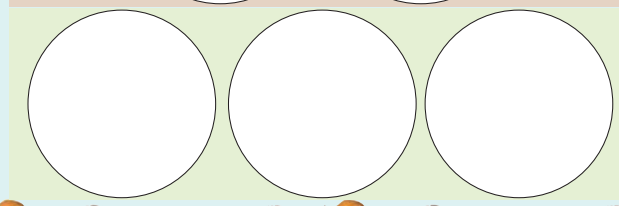

□ ÷ □ = □



Gwala okulandelako. Tlola ithothali yakho ngakunye.

iinqhema ezi-3 zangaku-2

+ Hlanganisa inani loke:

× Buyabuyelela inani loke:

iinqhema ezi-2 zangama-25

+ Hlanganisa inani loke:

× Buyabuyelela inani loke:

Yaba iimbalisi ezili-12 hlangana naku-4.

− Khupha inani loke:

÷ Hlukanisa inani loke:

Yaba iimbalisi ezima-36 hlangana naku-3.

− Khupha inani loke:

÷ Hlukanisa inani loke:

Bala.

iinqhema ezi-2 zangali-7 _____ iinqhema ezi-3 zangabu-8 _____

iinqhema ezi-4 zangaku-5 _____ iinqhema ezi-2 zangali-15 _____

yaba i-18 ngaku-2 _____ yaba ama-24 ngaku-3 _____

yaba ama-35 ngaku-5 _____ yaba ama-50 nge-10 _____

Bekuneenqhema ezisi-6 zabo-5 ephathini yami.
Bentwana abangaki ebebasephathini yami?

Teacher:
Sign:
Date:

11 12 13 14 15 16 17 18 19 20

Ilanga:

Ukuqhema nokwabelana

Mabhlogo amangaki endlulungeni ngayinye hlangana nabentwana?



Mangaki amabhlogo asendlulungeni ngayinye? Tlola inani elihlangeneko, inani ngendlulungeni ehlaza kwesibhakabhaka.

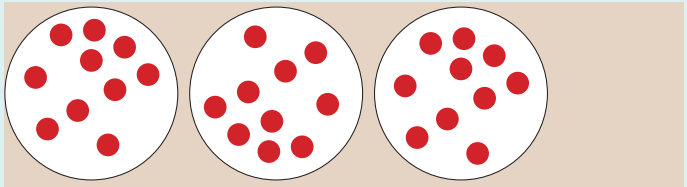



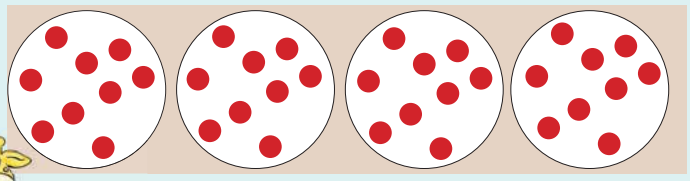

Yaba amabhlogo hlangana neendlulungu.



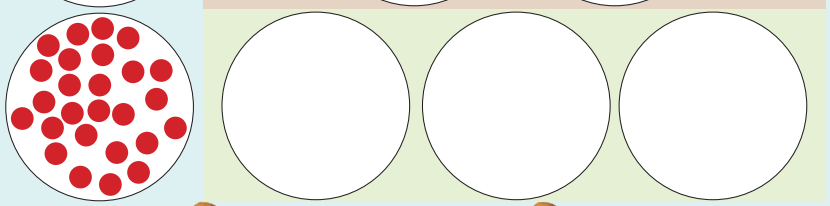



Gwala okulandelako. Tlola ithothali yakho ngakunye.

iinqhema ezi-3 zangaku-12

+ Hlanganisa inani loke:

× Buyabuyelela inani loke:

iinqhema ezi-5 zangama-10

+ Hlanganisa inani loke:

× Buyabuyelela inani loke:

Yaba iimbalisi ezili-24 hlangana naku-4.

— Khupha inani loke:

÷ Hlukanisa inani loke:

Yaba iimbalisi ezima-25 hlangana naku-5

— Khupha inani loke:

÷ Hlukanisa inani loke:

Bala.

iinqhema ezi-2 zangali-11 _____ iinqhema ezi-3 zangali- 10 _____

iinqhema ezi-4 zangaku-4 _____ iinqhema ezi-2 zangama-25 _____

yaba ama-20 ngaku-2 _____ yaba ama-27 ngaku-3 _____

yaba ama- 50 ngaku-5 _____ yaba ama-28 nge-2 _____

buyelela kabili

Teacher:

Sign:

Date:

11 12 13 14 15 16 17 18 19 20

Ilanga:

Ukuqhema nokwabelana

1 Zingaki iimbalisi ngendulungeni ngayinye ehlangana nabentwana ababili.



2 Zingaki iimbalisi ngendulungeni ngayinye?

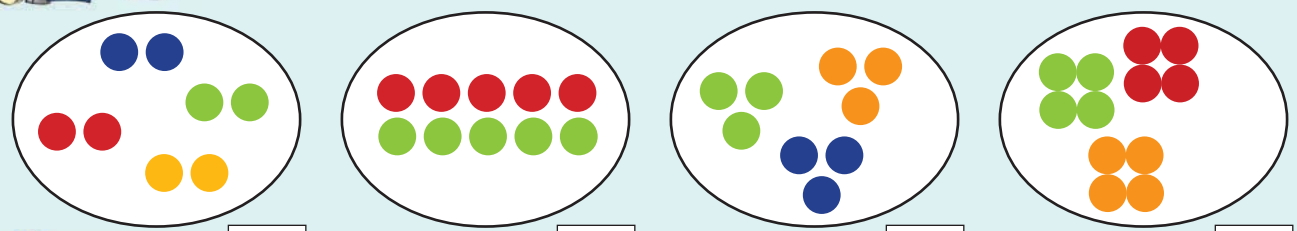

3 Sika amabumbeko kusika-4 bese uwanamathisele ebhlogweni elifaneleko. Bala amabumbeko.











4 Yabelana ngamabumbeko hlangana nabentwana. Sebenzisa amabumbeko weSika 2

aboncantathu





iinkwere









5 Yaba iinthelo hlangana kwabentwana. Gwala aboncantathu.





onama-orontji





onamahabhula









6 UJohn noBhelinda babelana amaswidi ali-12 ngokulingana. Umntwana ngamunye ufunyana amaswidi amangaki?

Teacher:

Sign:

Date:



Ilanga:

Ukuqhema nokwabelana

1 Mngaki umncamo owubala ngeenthoro endulungeni ngayinye ehlangana nabentwana.



2 Mngaki umncamo osendulungeni ngayinye?

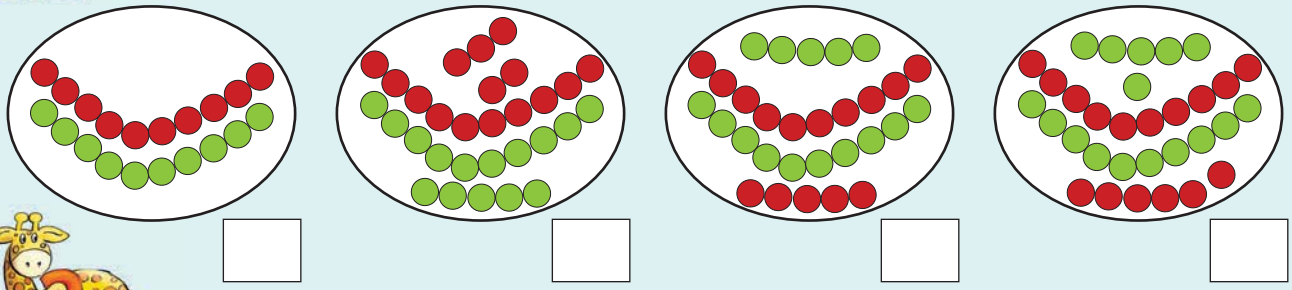

3 Sika umncamo kusika-4 bese uwunamathisela la.
Bala umncamo.

Umncamo obomvu	Umncamo obomvu
Umncamo osarulani	Umncamo ohlaza satjani



4 Gwala isibalo esilinganako somncamo womntwana ngamunye.









5 Yaba umncamo hlangana nabentwana. Gwala.

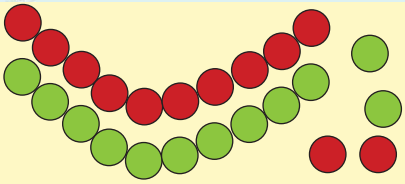

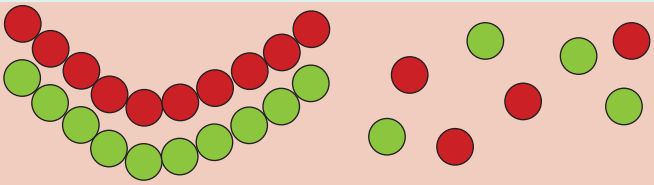













6 UBusi noZaheda babelana amakhrayoni ama-32 ngokulingana. Umntwana ngamunye ufunyene amakhrayoni amangaki?

Teacher:

Sign:

Date:



Ilanga:

Abohafu: 1–20

Kwenzekeni ngama-apula?



Yaba iinthelo ezingesinceleni uzabele ngemantjini engesidleni. Zigwale.

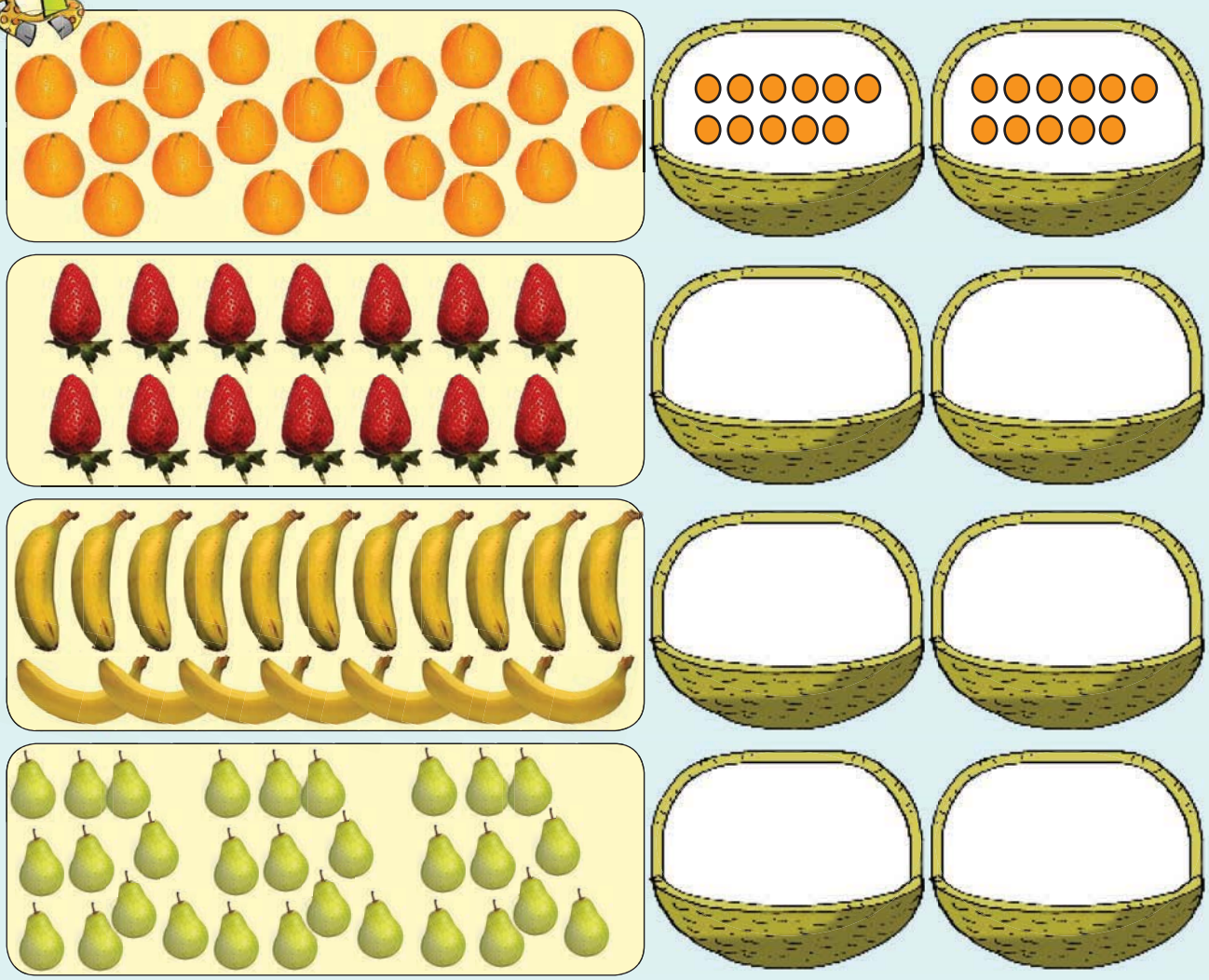



2 Thala umuda ukutjengisa ihafu.

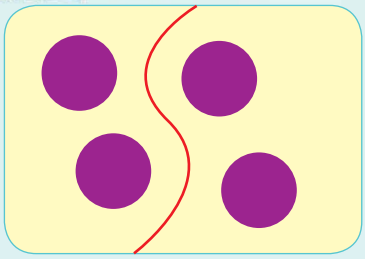

Ihafu yaku-4 2



Ihafu yesi-6



Ihafu yobu-8



Ihafu yaku-2

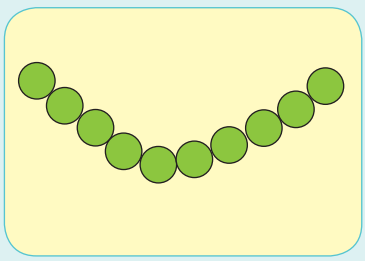

Ihafu ye-10

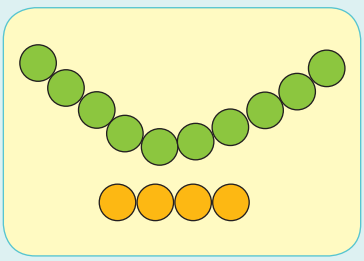

Ihafu ye-14

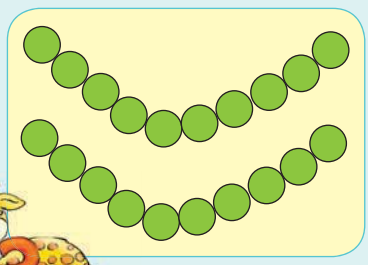

Ihafu yama-20

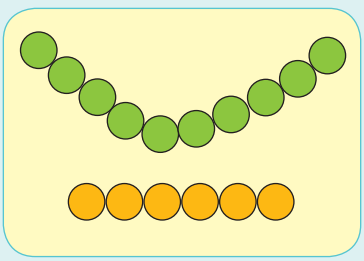

Ihafu ye-16

3 Iyini ihafu yepleyidi ngalinye lokudla?



Teacher:
Sign:
Date:

Ilanga:

Ukwabelana 20–50





Kwenzekeni ngomncamo?





Yaba umncamo ongesinceleni uwabele ngemantjini engesidleni. Ugwale.

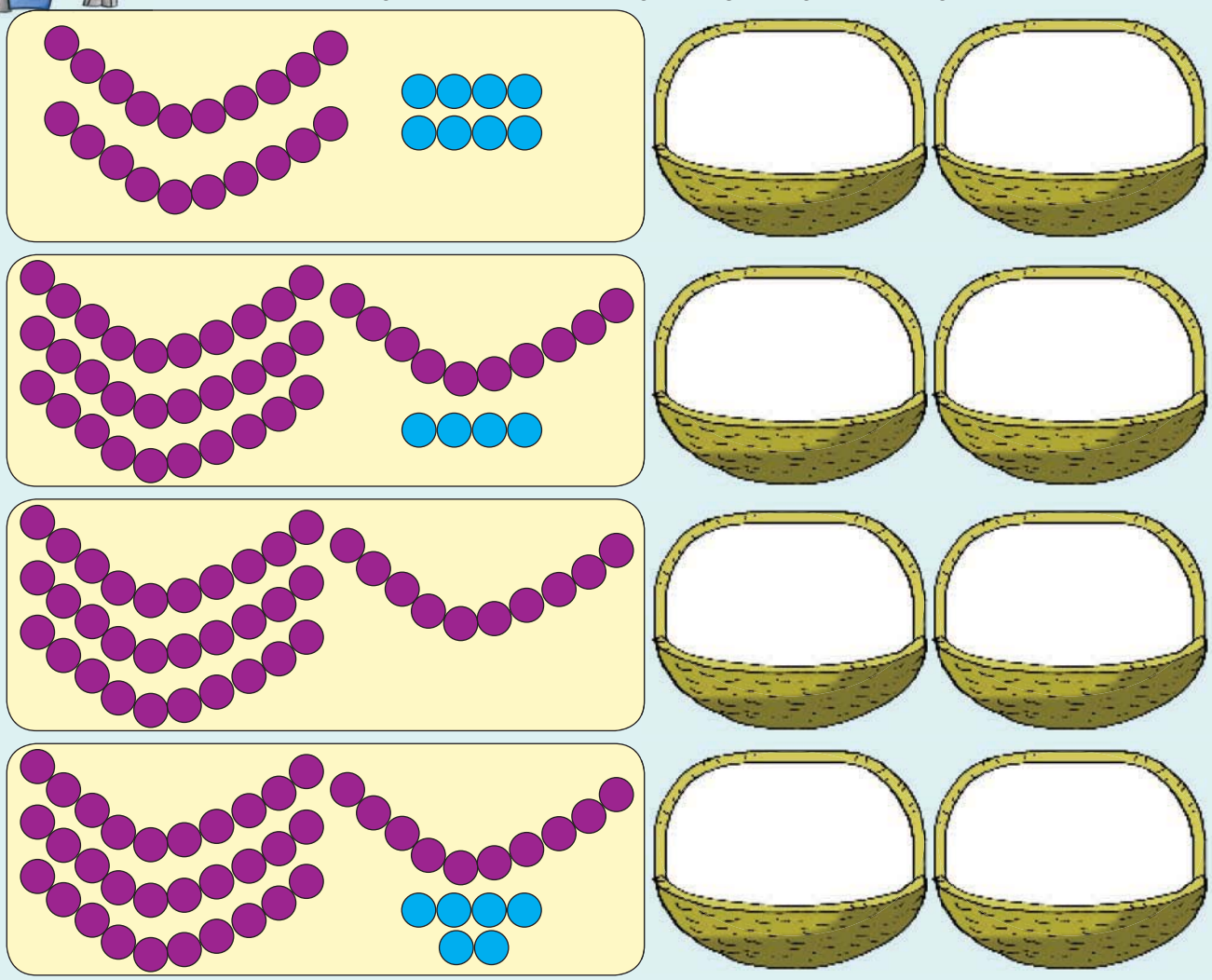



Yenza ihafu yinye yombala ohlukileko.

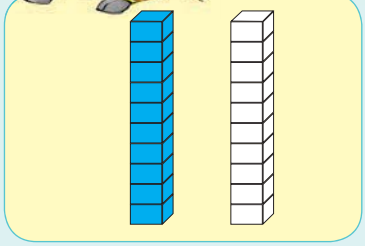

Ihafu yama - 20 10

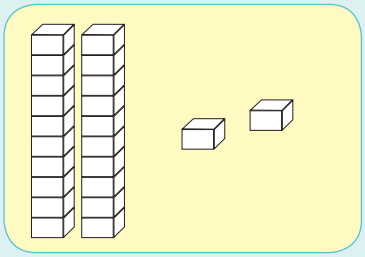

Ihafu yama - 22 ☐

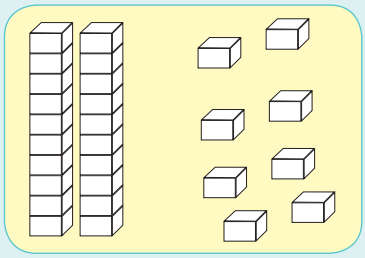

Ihafu yama - 28 ☐

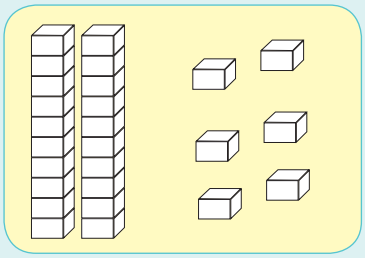

Ihafu yama - 26 ☐

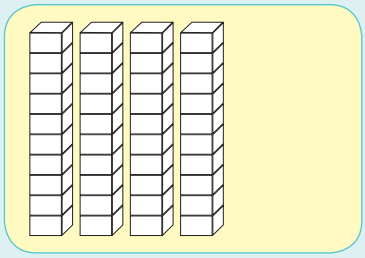

Ihafu yama - 40 ☐

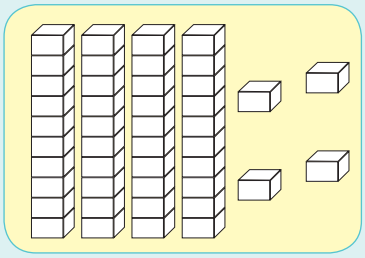

Ihafu yama - 44 ☐

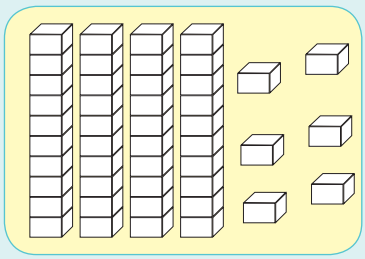

Ihafu yama - 46 ☐

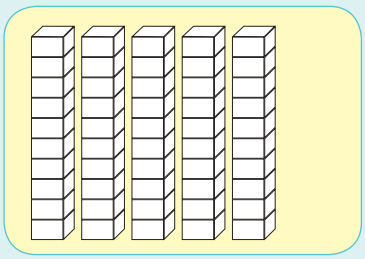

Ihafu yama - 50 ☐

Faka ihafu yedayagramu ngayinye umbala.



Teacher:
Sign:
Date:

11 12 13 14 15 16 17 18 19 20

Ilanga::

Idatha



Hlela iinthelo. Yenza umgwalo ongewakho ukutjengisa lokho.
Tlola inani ngaphakathi kwebhoksi.



Ngokuhlela ngikwazile ukubeka iinthelo ezifanako ndawonye.

Usika-1

Iphepha lokusebenzela-10 nama-40

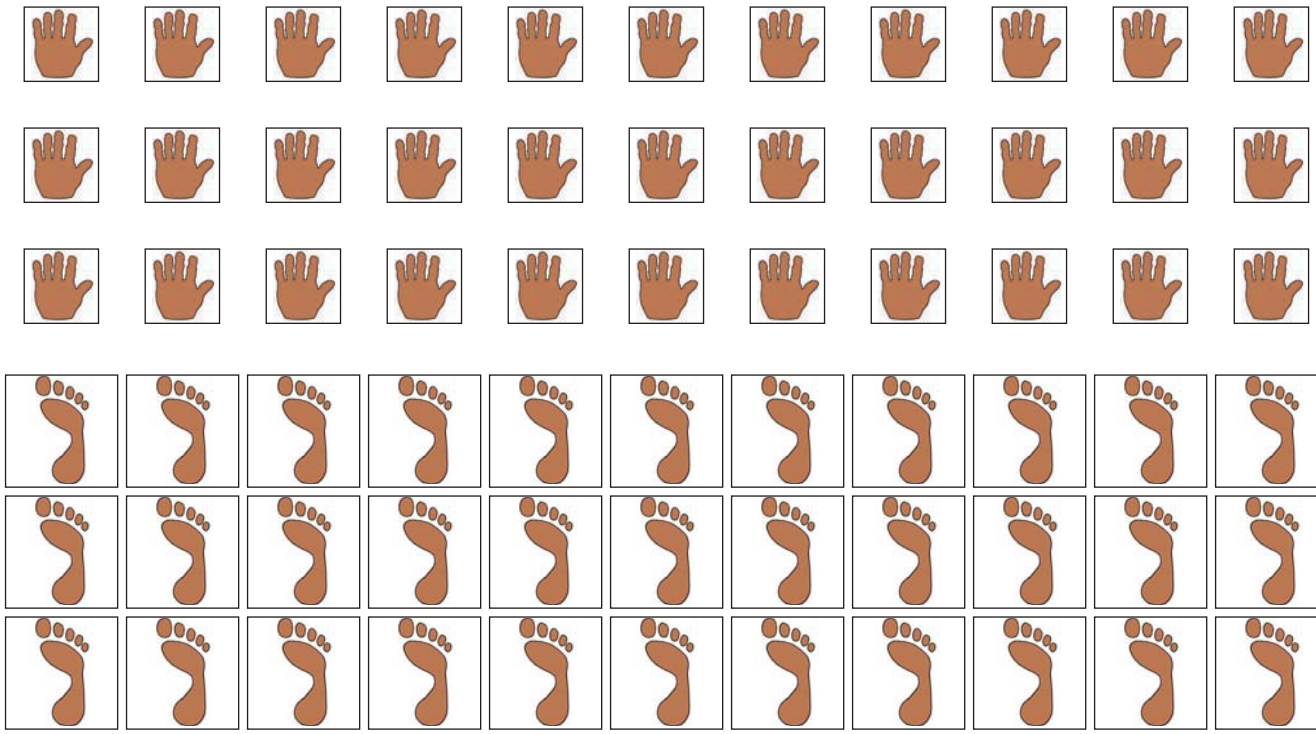

Iphepha lokusebenzela-13

ekuseni	entambama	ngemvakwamadina
ebusuku	phakathi kobusuku	ekuseni nangemva kwa-modina

Usika-2

Iphepha lokusebenzela-22

Umlando nezehlakalo eziqakathekileko

Ilanga lamalungelo

Ilanga lokubuyisana

Ilanga labasebenzi

Ilanga labatjha

Ilanga lamasiko

Ilanga labantu bengubo

Ilanga lekululeka

Amatshawayo wekolo



yamaBahayi | Ikolo yamaJuda | Ikolo yamaBuddhist | Ikolo yama-Islamu | Ikolo yamaKristu | Ikolo yeSintu | Ikolo yamaHindu