

UNkk Angie Motshekga, uNgqongqoshe weMfundo eyiSesekelo.



UMnu Enver Surty, iSekela loMnyango weMfundo eyiSesekelo.

Lezi zincwadi zokusebenzela zenzelwe abantwana baseNingizimu Afrika ngaphansi kwesandla sikaNgqongqoshe weMfundo eyiSesekelo, uNkk Angie Motshekga, neSekela likaNgqongqoshe weMfundo eyiSesekelo, uMnu Enver Surty.

Lezi zincwadi ezibizwa ngeRainbow Workbooks ziyingxenye yoMnyango weMfundo eyiSesekelo lapho uMnyango uzama khona ukungenelela ukuze kuthuthukiswe imfundo yabantwana bamabanga asuka kwelokuqala kuya kwelesithupha eNingizimu Afrika. UMnyango weZimali uxhase lo mkhankaso kaHulumeni njengento yokuqala uHulumeni azibekele yona ukuthi ayisukumele. Uxhaso loMnyango weZimali lusize uMnyango wezeMfundo ukuthi ukwazi ukukhiqiza uphinde usabalalise ngaphandle kwenkokhelo lezi zincwadi zokusebenzela ngazo zonke izilimi zaseNingizimu Afrika ezisemthethweni.

Sinethemba lokuthi othisha bazozithanda basebenze kangcono ngazo lezi zincwadi ekufundiseni kwabo kwansuku zonke, baphinde bathole futhi isiqiniseko sokuthi abafundi babo bafundiswa konke abamelwe ukufundiswa khona njengoba kuvela kusilabhasi yabo. Sizamile ukuqiniseka ukuthi sifaka izithonjana (ama-icon) emisebenzini yokwenziwa ukuze uthisha akuthole kulula ukuyilandela nokuqonda ukuthi umfundi yini alindeleke ukuyenza.

Sinethemba futhi lokuthi abantwana uqobo lwabo bazokujabulela ukusebenzisa lezi zincwadi ekukhuleni kwabo bakhule nolwazi eziluqukethe, bese kuthi wena njengothisha wabo uthokoze kanye nabo ekugcineni.

Sifisela wena nomfundi omfundisayo impumelelo ngenkathi usebenzisa lezi zincwadi.



Rainbow WORKBOOKS

MATHEMATICS IN ISIZULU
GRADE 2 – BOOK 1
TERMS 1 & 2
ISBN 978-1-920458-96-6

THIS BOOK MAY NOT BE SOLD.

1 2 3 4 5 6 7 8 9 10

+ − X ÷ =

IZIBALO NGESIZULU – Ibanga lesi-2 Incwadi yoku-1

ISBN 978-1-920458-96-6



IZIBALO NGESIZULU

Ibanga lesi-2

Incwadi yoku-1
Ithemu 1 & 2

Igama:

Iklasi:

basic education
Department:
Basic Education
REPUBLIC OF SOUTH AFRICA

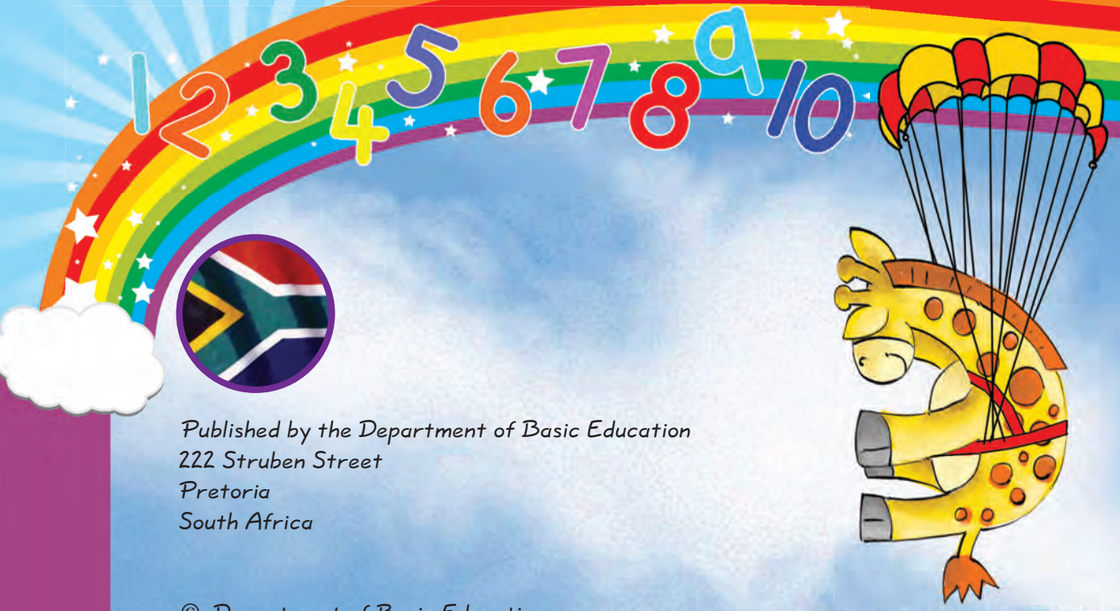



1 – 100

1	2	3	4	5	6	7	8	9	10
11	12	13	14	15	16	17	18	19	20
21	22	23	24	25	26	27	28	29	30
31	32	33	34	35	36	37	38	39	40
41	42	43	44	45	46	47	48	49	50
51	52	53	54	55	56	57	58	59	60
61	62	63	64	65	66	67	68	69	70
71	72	73	74	75	76	77	78	79	80
81	82	83	84	85	86	87	88	89	90
91	92	93	94	95	96	97	98	99	100

Published by the Department of Basic Education
222 Struben Street
Pretoria
South Africa

© Department of Basic Education
Third edition 2013

ISBN 978-1-920458-96-6

The Department of Basic Education has made every effort to trace copyright holders but if any have been inadvertently overlooked, the Department will be pleased to make the necessary arrangements at the first opportunity.

This book may not be sold.



basic education
Department:
Basic Education
REPUBLIC OF SOUTH AFRICA

1 2 3 4 5 6 7 8 9 10 11 12 13 14 15 16 17 18 19 20 21 22 23 24 25 26 27 28 29 30 31 32 33 34 35 36 37 38 39

IBanga lesi- 2

Rainbow WORKBOOKS

Izibalo

ngesiZulu

Le ncwadi ngeka:



ISIZULU

Incwadi yoku-

1

1

Usuku:

Mina nomndeni wami



Gcwalisa izimpendulo kule mibuzo emayelana nawe nomndeni wakho.

Igama lami ngingu _____ .

Nginemnyaka e _____ ubudala.

Eminyakeni emibili eyedlule nganginemnyaka e _____ ubudala.

Onyakeni owodwa ozayo ngizoba neminyaka e _____ ubudala.

Ngihlala e _____ .

Ubani omdala emndenini wakho? _____ .

Bhala ukuthi uneminyaka emingaki ubudala. _____ .

Ubani omncane emndenini wakho? _____

Bhala ukuthi uneminyaka emingaki ubudala. _____

Usuku namuhla umhlaka _____ .

1 2 3 4 5 6 7 8 9 10





Dweba isithombe somndeni wakho.



1 2 3 4 5 6 7 8 9

Teacher:

Sign:

Date:

11 12 13 14 15 16 17 18 19 20

Usuku: _____

Ukubala







amehlo		2
amachashaza	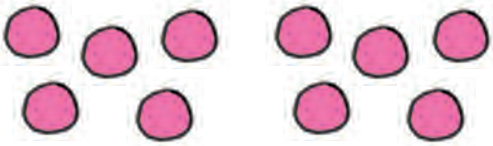	
iziqeshana		



amehlo		
amachashaza		
iziqeshana		







amehlo

amachashaza

iziqeshana



amehlo

amachashaza

iziqeshana



Abelanani amachashazi namapheshi ngokulinganayo.

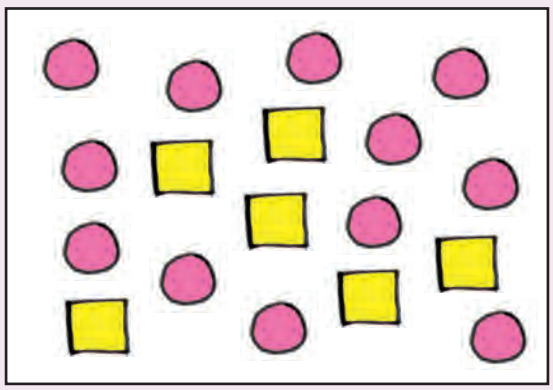







Teacher:
Sign:
Date:

Usuku:

Izinombolo



Funda izinkomba zezinombolo kanye namagama asebhodini.

1 73 59 66 35 42 97 24 32

Isishiyagalolunye

Ishumi nane

Ishumi nanye

Ishumi nesikhombisa

Ishumi nesishiyagalolunye

Isithupha

Ishumi

Kune



Bhala inombolo yobuhlalu obusebhokisini.

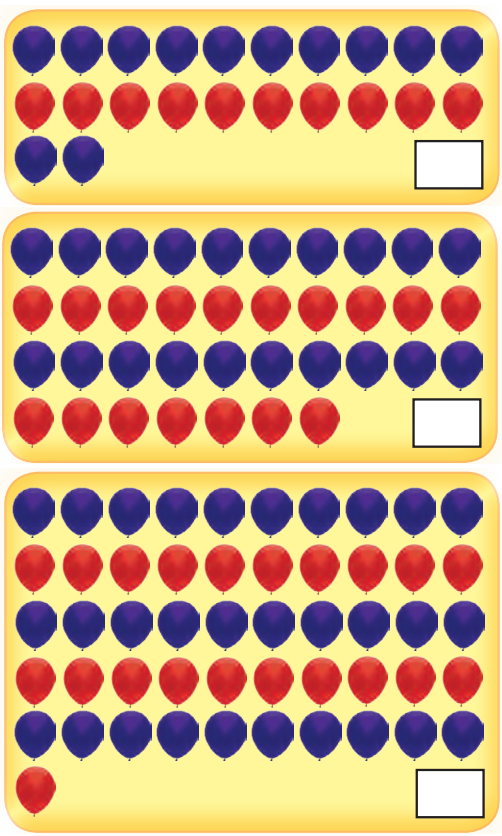





Bhala lezi zinombolo ezilandelayo ngamagama.



6 _____ 12 _____

4 _____ 7 _____

8 _____ 17 _____

1 _____ 14 _____

2 _____ 22 _____

5 _____ 18 _____

0 _____ 11 _____

10 _____ 20 _____

3 _____ 15 _____

9 _____ 13 _____



37 38 39 40 41 42 43 44

89 90 91 92 93 94 95 96 97



Teacher:

Sign:

Date:



11 12 13 14 15 16 17 18 19 20

4

Usuku:

Izinombolo



Dweba △ ezinombolweni ezingelona ugweje kanye ne ◯ kwezilugweje.

Ezingelona ugweje	1	2	3	4	5	6	7	8	9	10
Ezilugweje	11	12	13	14	15	16	17	18	19	20

Faka izinombolo ezindlini.



1 2 3 4 5 6 7 8 9 10



Bala imibala emibili yobuhlalu



Bhala inombolo yalokhu:

10 2 = 12

10 3 = ☐

10 5 = ☐

10 8 = ☐

10 9 = ☐

Singakubhala kanje:

10 + 2 = 12

☐ + ☐ = ☐

☐ + ☐ = ☐

☐ + ☐ = ☐

☐ + ☐ = ☐



Ithini impendulo?

10 + 1 = ☐	10 + 9 = ☐	10 + 6 = ☐
10 + 8 = ☐	10 + 2 = ☐	10 + 3 = ☐
10 + 5 = ☐	10 + 4 = ☐	10 + 7 = ☐



1 3 5 7 9 11 13 15 17 19

2 4 6 8 10 12 14 16 18 20

Teacher:

Sign:

Date:



11 12 13 14 15 16 17 18 19 20

Usuku:

Ukuhlanganisa nokususa



Hlanganisa uphinde ususe.



9 + 8 = 17



18 − 8 = ☐



☐ + ☐ = ☐



☐ + ☐ = ☐



☐ + ☐ = ☐

Bala.

6 + 5 = ☐	8 + 9 = ☐	11 + 3 = ☐	12 − 5 = ☐
8 + 7 = ☐	3 + 8 = ☐	9 − 5 = ☐	16 − 9 = ☐
6 + 4 = ☐	8 + 4 = ☐	8 − 4 = ☐	6 − 4 = ☐



Hlanganisa.

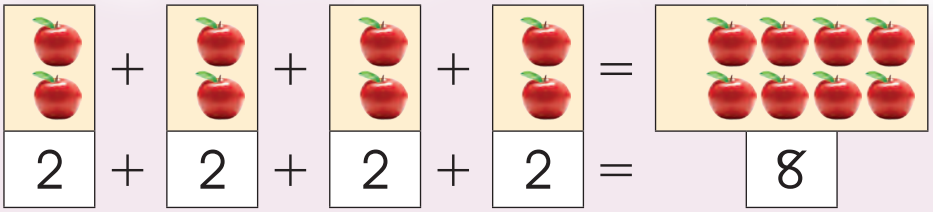

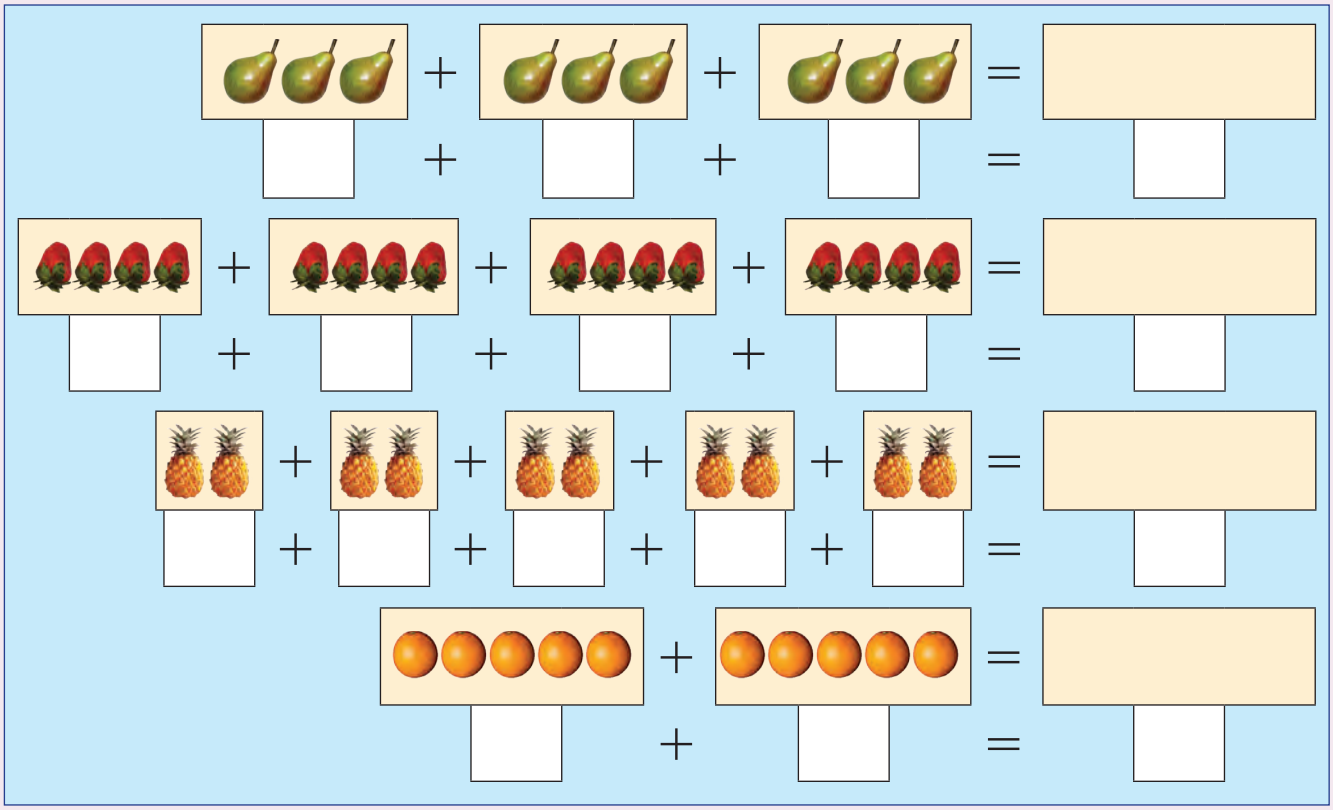



Bala.

2 + 2 + 2 = ☐	1 + 1 + 1 + 1 + 1 + 1 = ☐	2 + 2 + 2 + 2 = ☐
4 + 4 = ☐	3 + 3 + 3 + 3 = ☐	4 + 4 + 4 + 4 = ☐
5 + 5 + 5 = ☐	5 + 5 = ☐	1 + 1 + 1 = ☐





2 + 2 + 2 + 2 + 2 + 2

Teacher:
Sign:
Date:



Usuku:

Ukwabelana kanye nemali





Yabelana nabanye ngezithelo ezingezansi.





4



4



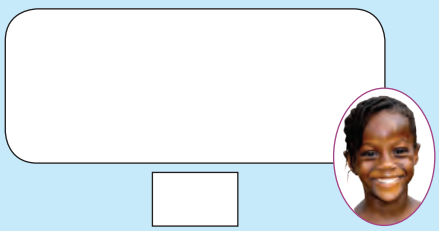

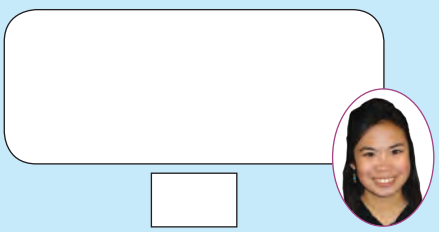



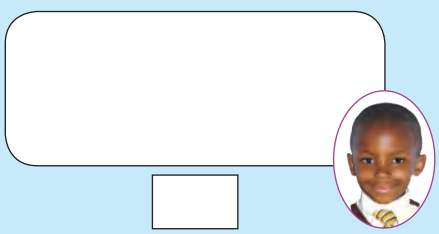

















Qedela.



Isenti eli-1					





Faka umbala ezinhlamvini zemali ezenza inani elifanayo uma zihlanganisiwe.



10c	10c	5c	2c	1c	2c



5c	2c	2c	1c	2c	2c



R2	R2	R1	R1	R1



=

R5	R2	R1	R5	R1	R2



=

R2	R2	R5	R5	R2	R1	R5



R1 1c R5 5c R10

Teacher:
Sign:
Date:



11 12 13 14 15 16 17 18 19 20

Usuku:

Amaphethini

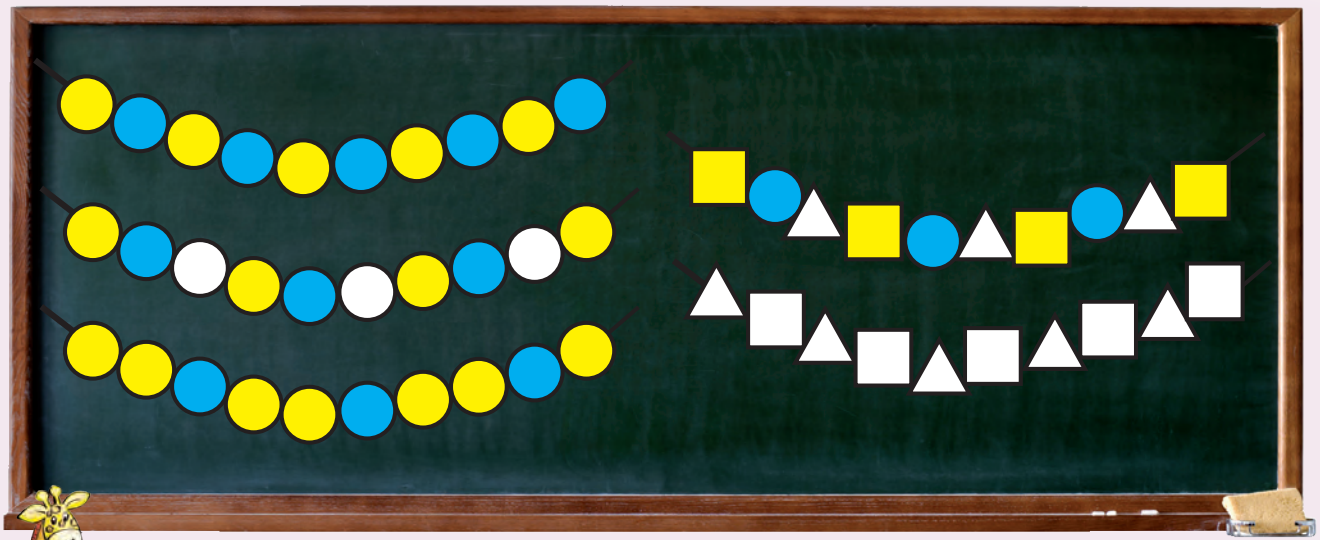



Kopisha amaphethini asebhodini.





Nweba iphethini.



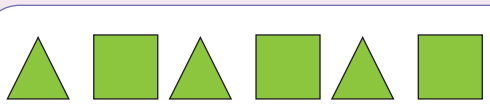







Faka umbala ebuhlalwini njengoba uqhubeka ubala ngakubili.

2	4	6							



Faka umbala ezimbalini njengoba ubala ngakuhlanu.

5	10	15							



Faka umbala ebuhlalwini njengoba ubala ngamashumi.

10	20	30							



OLIAOLIAOLIA

Teacher:
Sign:
Date:

11 12 13 14 15 16 17 18 19 20

Usuku:

Imifanekiso



Faka umbala oluhlaza konxande, obomvu ezindilingeni kanye nophuzi konxantathu.

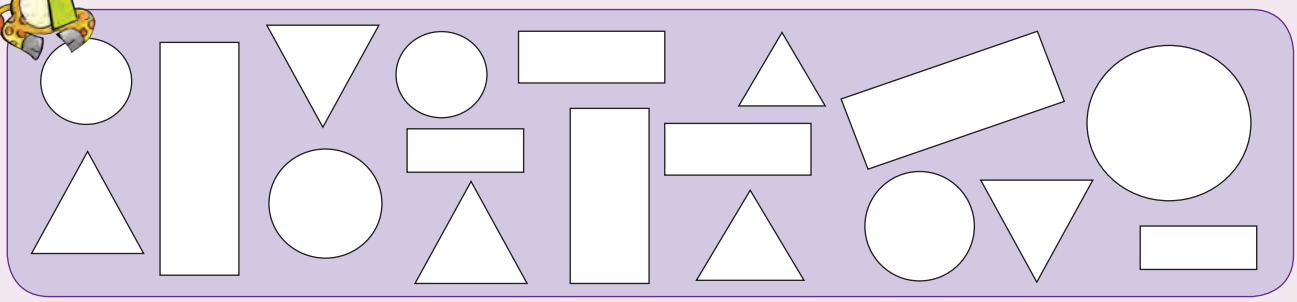

Faka umbala obomvu kuzo zonke izindilinga ezinkulu, oluhlaza konxande kanye nophuzi konxantathu abancane.

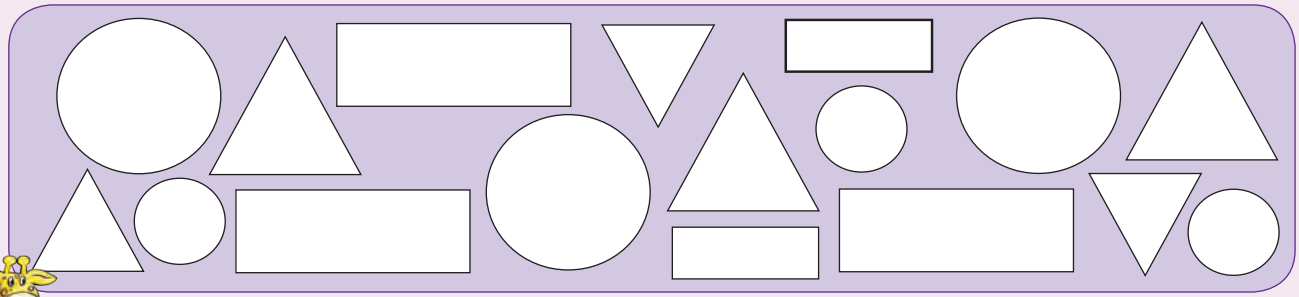

Faka umbala empendulweni eyiyo.



Okuqondile | Okuyindilinga



Okuqondile | Okuyindilinga



Okuqondile | Okuyindilinga





Dweba ezinye izinhlangothi zezimvemvane.





Teacher:

Sign:

Date:



Usuku:

Amabhola namabhokisi





Zungelezela amabhokisi ngombala oluhlaza kanye namabhola ngombala obomvu.



Faka umbala empendulweni eyiyo.



Ibhokisi | liyashibilika | liyagingqika



Ibhola | liyashibilika | liyagingqika



3 Faka umbala empendulweni eyiyo.



Inqenqema eyindilinga

Inqenqema eyindilinga



Inqenqema eyindilinga

Inqenqema eyindilinga



Inqenqema eyindilinga

Inqenqema eyindilinga



Inqenqema eyindilinga

Inqenqema eyindilinga



Inqenqema eyindilinga

Inqenqema eyindilinga



Inqenqema eyindilinga

Inqenqema eyindilinga



Inqenqema eyindilinga

Inqenqema eyindilinga



Inqenqema eyindilinga

Inqenqema eyindilinga

4 Yisho ukuthi ibhola lingemuva, ngaphambili, eduze noma ngaphezulu kwebhokisi.



ngemuva | ngaphambili

eduze | ngaphezulu



ngemuva | ngaphambili

eduze | ngaphezulu



ngemuva | ngaphambili

eduze | ngaphezulu



ngemuva | ngaphambili

eduze | ngaphezulu



ibhola bhokisi i bhola bhokisi

Teacher:

Sign:

Date:



11 12 13 14 15 16 17 18 19 20

Usuku: _____

Ubude



Isiphi isitimela eside noma esifushane?

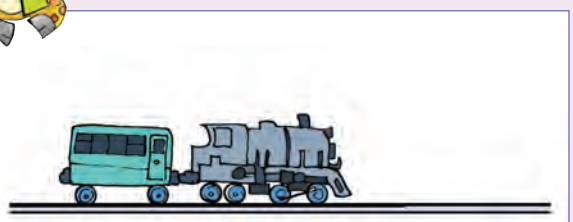



esifushane | eside

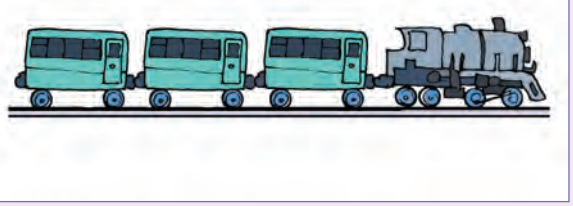

esifushane | eside

Isiphi isakhiwo esiphakeme noma esifushane?

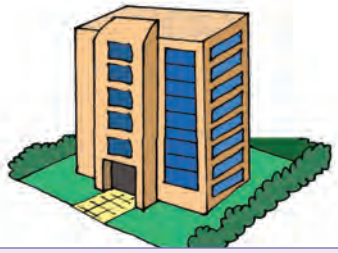

esiphakeme | ngaphansana





esiphakeme | ngaphansana



Imuphi umuntu omfushane noma omude?



Omfushane	Omfushane
Omude	Omude



Sebenzisa isandla esisikiwe. Uyizandla ezingaki ubude lo omfushane?
Sebenzisa unyawo olusikiwe. Uyizinyawo ezingaki ubude lo omfushane?



Manje kala ngezandla nangamanyathelo ukuphakama kwalo nxande.



Teacher:
Sign:
Date:



11 12 13 14 15 16 17 18 19 20

II

Usuku:

Isisindo





Isho ukuthi into iyasinda noma ilula.



iyasinda	ilula

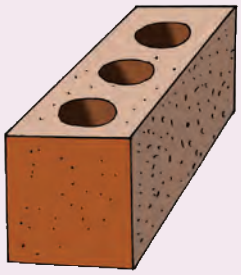

iyasinda	ilula



Zungelezela into esindayo.















Ingabe into inesikali esingaphezulu noma esingaphansi kwekhilogramu elilodwa?



kuyasinda | kulula



kuyasinda | kulula



kuyasinda | kulula



kuyasinda | kulula



iyasinda ilula

Teacher:
Sign:
Date:



Usuku:

Umthamo



Faka umbala empendulweni efanele.



kugcwele	akunalutho	kuwuhhafu



kugcwele	akunalutho	kuwuhhafu



kugcwele	akunalutho	kuwuhhafu



kugcwele	akunalutho	kuwuhhafu



kugcwele	akunalutho	kuwuhhafu



kugcwele	akunalutho	kuwuhhafu

1 2 3 4 5 6 7 8 9 10





Isilinganiso esisodwa singafika ophawini lokuqala kulo jeke.
Izilinganiso ezingaki ezingagcwalisa lo jeke?





Kuthelwe izilinganiso ezingaki kulaba ojeke?

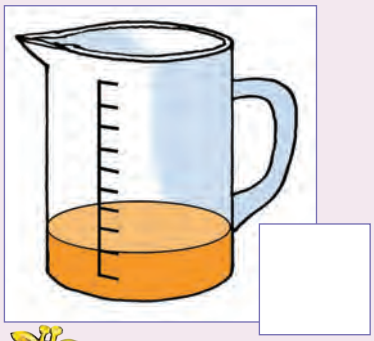



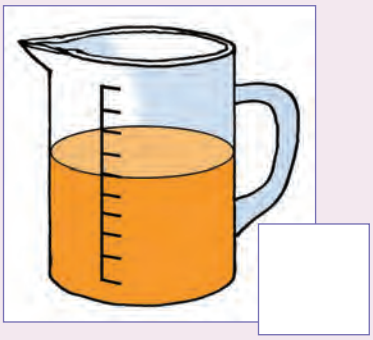



Ujeke osesandleni sesinxele uphethe amanzi angangelitha eyodwa.
Imuphi ujeke onesilinganiso esifanayo kanti futhi imuphi onejusi encane.





kuyalingana | kuncane



kuyalingana | kuncane



kugcwele akunalutho

Teacher:
Sign:
Date:



11 12 13 14 15 16 17 18 19 20

Usuku: _____

Isikhathi

Yiya kokusikwayo kokuqala. Sika amagama bese uwanamathisela ngaphansi kwezithombe.



Qedela imisho.

Ngi _____ ekuseni kakhulu.

Ngi _____ ekuseni.

Ngi _____ ntambama.

Ngi _____ zonke izinsuku.

Ngi _____ emva kwesikhathi zonke izinsuku.

1 2 3 4 5 6 7 8 9 10



Izolo	Namhlanje	Kusasa
		



Phendula imibuzo.

Zenzani izingane namhlanje? _____

Bezenzani izingane izolo? _____

Zizokwenzani izingane kusasa? _____



Dweba isithombe sakho.

Izolo	Namhlanje	Kusasa



Izolo





Teacher:
Sign:
Date:



11 12 13 14 15 16 17 18 19 20



Usuku:

Ikhalenda Losuku Lokuzalwa



Qopha izinyanga.

uMasingana
uSipho
uMaryke
uAnnie

uNhlolanja
uJeffrey
uSimon

uNdasa
uSam
uJuan

uMbasa
uBetty
uLiezel

uNhlaba
uLettie
uRicco
uGeorge

uNhlangulana
uMpho

uNtulikazi
uPalesa
uLisa
uKayla

uNcwaba
uMbali
uBrenda
uMary

uMandulo
uJohn

uMfumfu
uKarin
uJaco

uLwezi
uGugu
uDian

uZibandlela
uKara
uRichard
uDenise

1 2 3 4 5 6 7 8 9 10





Bhala igama lengane ngayinye ekhalendeni lezinsuku zokuzalwa.

uMasingana	uNhlolanja	uNdasa
uMbasa	uNhlaba	uNhlangulana
uNtulikazi	uNcwaba	uMandulo
uMfumfu	uLwezi	uZibandlela



usuku lwami lokuzalwa

Teacher:

Sign:

Date:



Usuku: _____

Qoqa uhlele ngononina



Qoqa bese uhlela ngononina amabhola bese uwadweba ebhokisini elifanele.

Amabhola aluhlaza okotshani	Amabhola abomvu	Amabhola aluhlaza	Amabhola aphuzi

Qoqa izimbali bese uzibeka ngononina.

Izimbali eziphuzi	Izimbali ezibomvu	Izimbali ezinsomi	Izimbali ezipinki	Izimbali ezisawolintshi
				



Hlela izinto ngononina. Zidwebele okwakho.



izinto ezilula

izinto ezisindayo



Amabhola amacane

Amabhola amakhulu

Amabhokisi amancane

Amabhokisi amakhulu



Teacher:

Sign:

Date:



11 12 13 14 15 16 17 18 19 20

Usuku: _____

Funda bese uyatolika



Umdwebo wami





Hlela amakhilayoni ngononina. Yenza umdwebo wawo.





Hlela amakhilayoni ngononina. Yenza umdwebo wawo.





Hlela amafu nothingo. Kudwebe.





Phendula imibuzo.

		
onxantathu	onxande	izindilinga

Bangaki onxantathu abalapho? _____

Bangaki onxande abalapho? _____

Zingaki izindilinga ezilapho? _____

Onxantathu noma onxande abaningi? _____

Izindilinga noma onxantathu abaningi? _____

Izindilinga noma onxande abaningi? _____

		
akunalutho	kuwuhhafu	kugcwele

Bangaki ojeke abangenalutho? _____

Bangaki ojeke abacishe bagcwale? _____

Bangaki ojeke abagcwele? _____





Teacher:

Sign:

Date:



Usuku: _____

Ngaphambili ngemuva naphakathi

Chaza izinombolo usebenzise amagama "ngaphambili", "phakathi" kanye no"engemuva".

1	2	3	4	5	6	7	8	9	10	11	12	13	14	15	16	17	18	19	20	21	22	23	24	25

Isb. Ibhola ngalinye kwabomvu liphakathi kwamabili asasibhakabhaka.

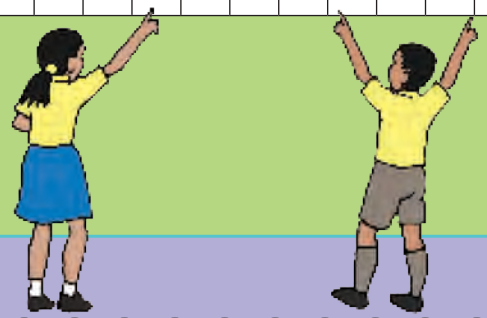



2

Bhala inombolo efanele esikweleni.

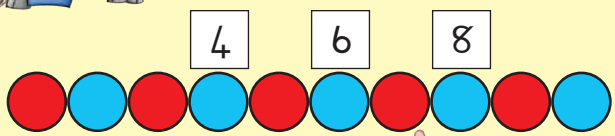

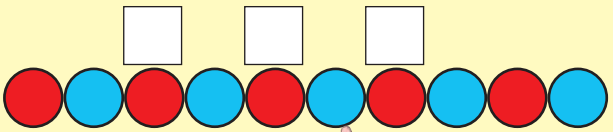

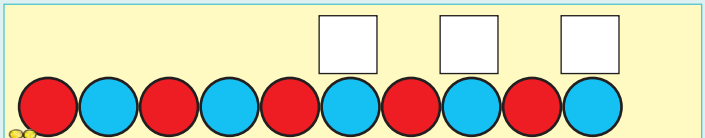

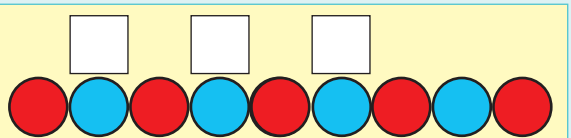

3

Faka izinombolo ezingekho.

	2			5	
	12			15	
13			16		

10			13		
	17			20	
20					25

1	2	3	4	5	6	7	8	9	10	11	12	13	14	15	16	17	18	19	20	21	22	23	24	25

Iyiphi inombolo engaphambili kuka-8? _____

Iyiphi inomboloengemuva kuka-16? _____

Iziphi izinombolo eziphakathi kuka-8 no-12? _____





Faka umbala oluhlaza ezinombolweni eziphakathi kuka-14 no-17. Faka umbala obomvu enombolweni engaphambi kuka-14. Faka umbala ophuzi enombolweni engemuva kuka-17.

11	12	13	14	15	16	17	18	19	20

11 12 13 14 15 16 17 18 19 20 21 22 23 24 25 26 27 28 29 30

Bhala zonke izinombolo ezisebuhlalwini obuphuzi.
Sizibiza ngani izinombolo ezisebuhlalwini obuphuzi.

_____

Bhala zonke izinombolo ezisebuhlalwini obuphinki.
Sizibiza ngani izinombolo ezisebuhlalwini obuphinki.

_____

1 2 3 4 5 6 7 8 9 10 11 12 13 14 15 16 17 18 19 20



Hlukanisela izingane eziqoke okuphuzi ubuhlalu obuphuzi.

Umuntu ngamunye uthola ubuhlalu obungaki? _____ . Bukhona ubuhlalu obusalayo? _____

Hlukanisela izingane eziqoke okupinki ubuhlalu obupinki.

Ingane ngayinye ithola ubuhlalu obungaki? _____ .Bukhona ubuhlalu obusalayo?_____

Phendula imibuzo elandelayo.

Iyiphi inombolo engelona ugweje eza emva kuka-12? _____

Iyiphi inombolo elugweje eza emva kuka-14? _____

Iziphi izinombolo ezilugweje eziphakathi kuka-10 no-16? _____

Bhala izinombolo ezingelona ugweje eziphakathi kuka-8 no-18?_____

Teacher:
Sign:
Date:

11 12 13 14 15 16 17 18 19 20

Usuku:

Izinombolo Ikuya ku-30

Ubala izincwadi ezingaki?
Ubala ojeke abangaki bapende?



Ubala ubuhlalu obungaki?

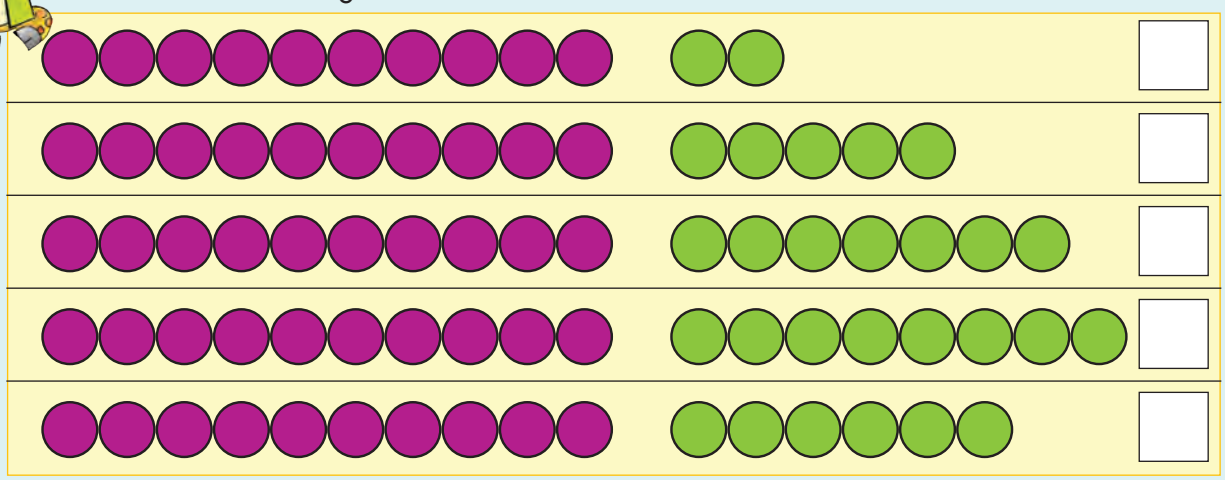

Ubala izincwadi ezingaki?



Faka inombolo engekho.

14	12	15	17	19	13	26	28	21	30
10 4	2	10	7	10					

1 2 3 4 5 6 7 8 9 10



Buka isibonelo sokuqala bese uqedela okulandelayo.

18	=	1	ishumi	+	8	imivo	noma	18	=	10	+	8
15	=		ishumi	+		imivo	noma		=		+	
19	=		ishumi	+		imivo	noma		=		+	
22	=		ishumi	+		imivo	noma		=		+	
24	=		ishumi	+		imivo	noma		=		+	

Ubala ubuhlalu obungaki?

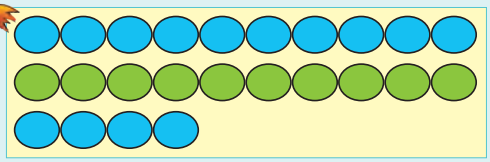

Inombolo

Singayibhala kanje.

20 + ☐ = 24

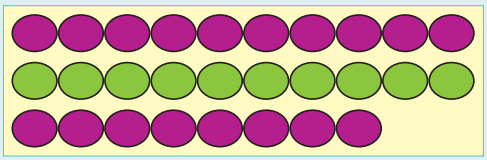

Inombolo

Singayibhala kanje.

20 + ☐ = 28

Bhala igama layo.

10	_____	11	_____
12	_____	13	_____
14	_____	15	_____
16	_____	17	_____
18	_____	19	_____
20	_____	21	_____
22	_____	23	_____
24	_____	25	_____

Bheka isibonelo sokuqala bese uqedela okulandelayo.

25	=	2	ishumi	+	5	imivo		22	=	2	ishumi	+	2	imivo
13	=		ishumi	+		imivo		21	=		ishumi	+		imivo
26	=		ishumi	+		imivo		19	=		ishumi	+		imivo

Teacher:
Sign:
Date:

11 12 13 14 15 16 17 18 19 20

Usuku: _____

Imigqa yezinombolo



Faka izinombolo ezingekho.

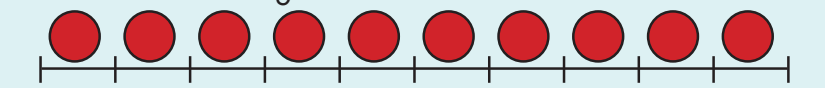

0	1			4						10

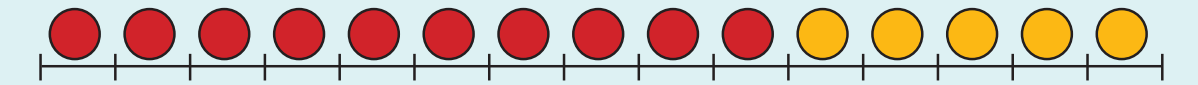

0					5	6									15

Ixoxo ligxume laya kude kangakanani? Sebenzisa umugqa wezinombolo kulokhu.



0	1	2	3	4	5	6	7	8	9	10

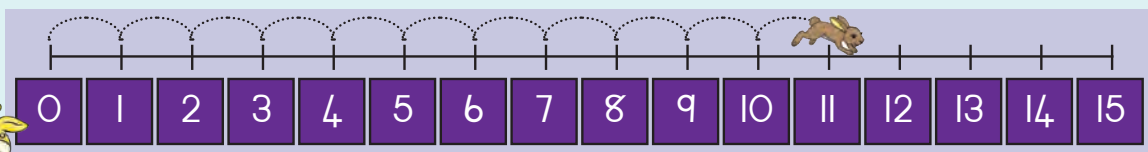

0	1	2	3	4	5	6	7	8	9	10	11	12	13	14	15

Impala igxume yaya kude kangakanani? Sebenzisa umugqa wezinombolo kulokhu.

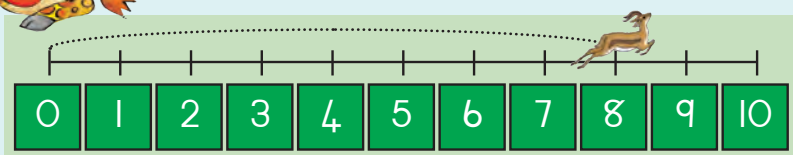

0	1	2	3	4	5	6	7	8	9	10

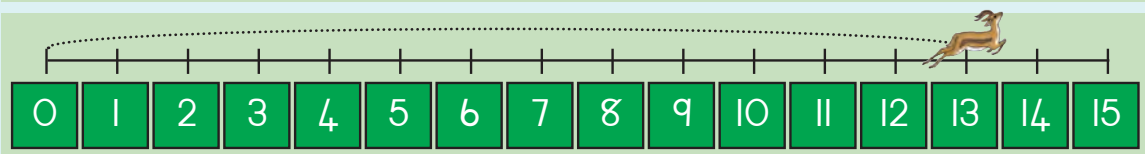

0	1	2	3	4	5	6	7	8	9	10	11	12	13	14	15



Qedela umugqa wezinombolo. Ixoxo ligxume laya kude kangakanani?

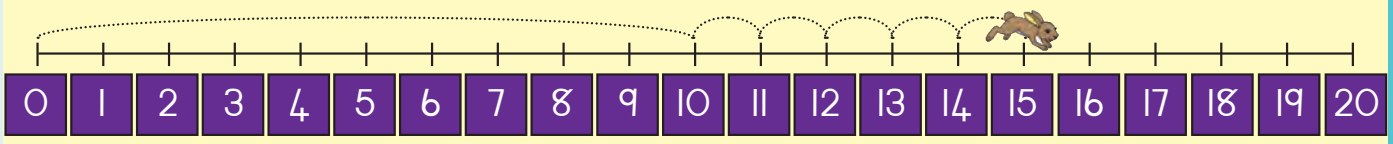

ishumi imivo

10 + 5 =

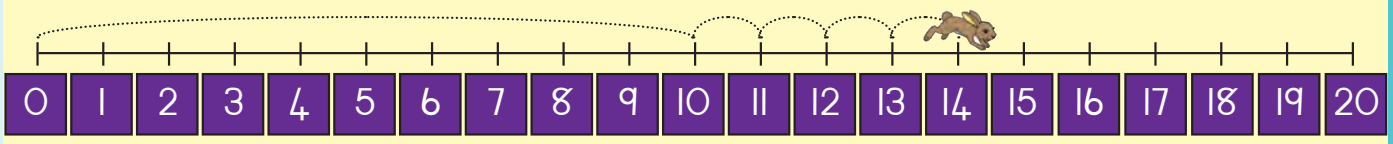

ishumi imivo

\+ =

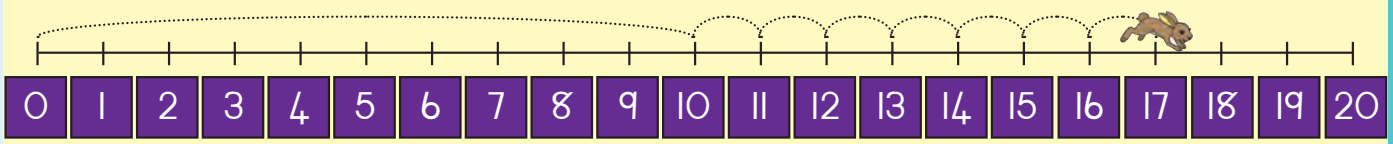

ishumi imivo

\+ =

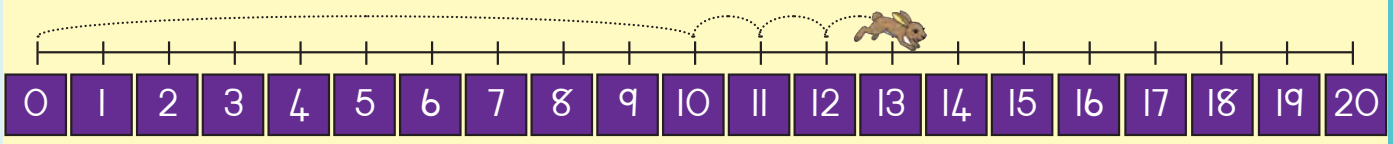

ishumi imivo

\+ =

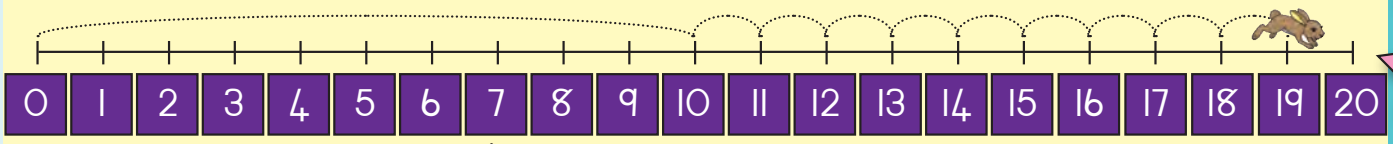

ishumi imivo

\+ =

Teacher:

Sign:

Date:



Usuku:

Eminye imgqa yezinombolo





Siza ixoxo libhale isibalo. Sebenzisa umugqa wezinombolo kulokhu.

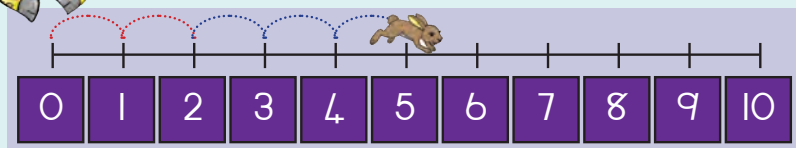

2 + 3 = 5

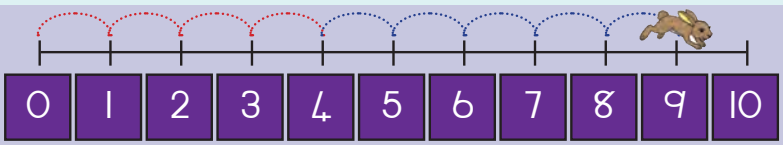

__ + __ = __



Siza impala ibhale isibalo.
Sebenzisa umugqa wezinombolo kulokhu.

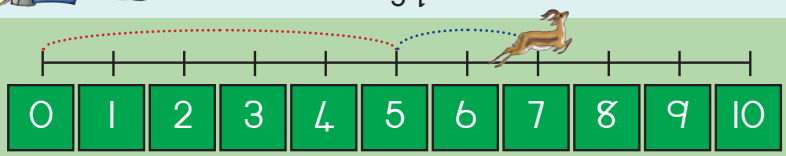

__ + __ = __

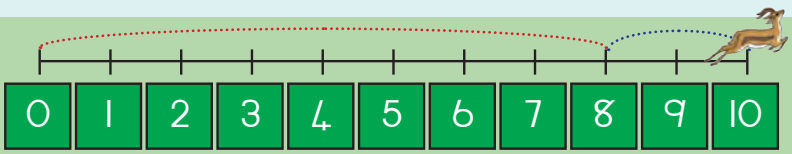

__ + __ = __







Siza ixoxo libhale isibalo.

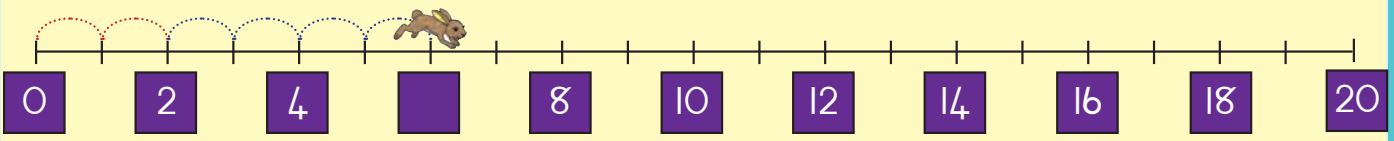

2 + 4 = 6

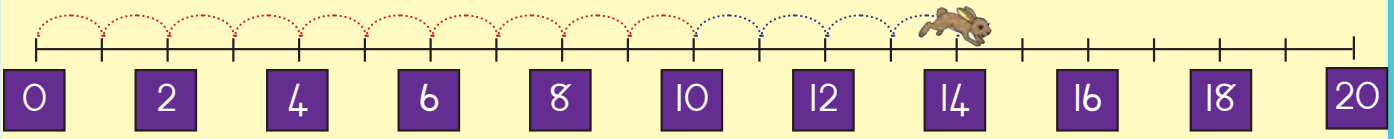

__ + __ = __



Siza impala ibhale.

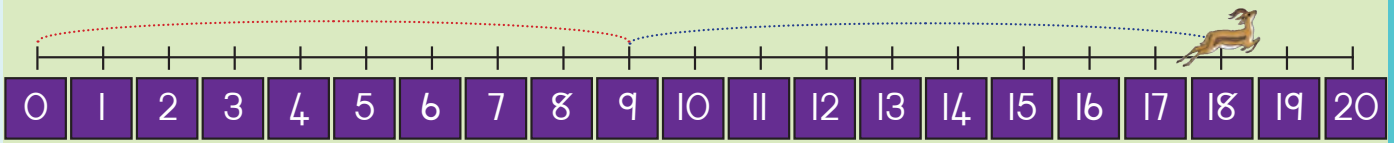

9 + 9 = __

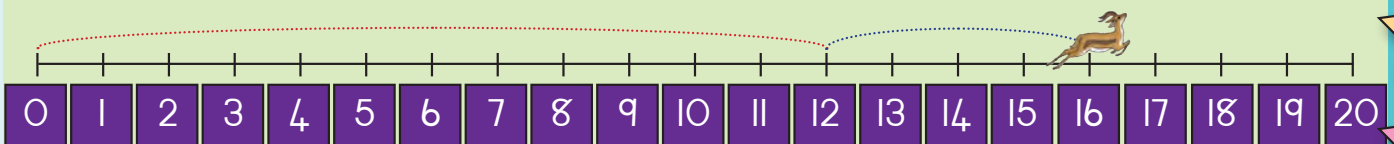

__ + __ = __



Teacher:

Sign:

Date:



Usuku:

Ukuhlanganisa nokususa

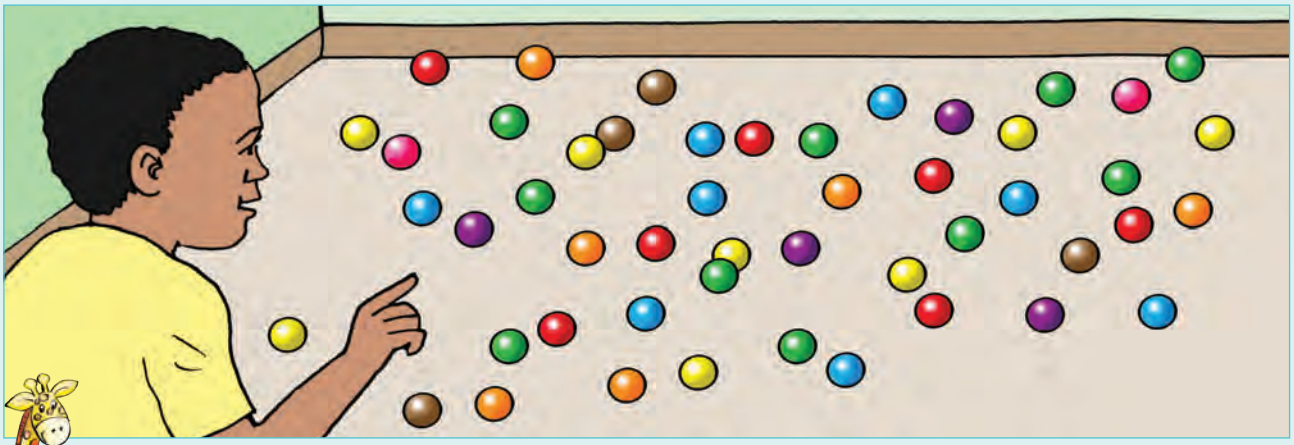



Bhala inani lobuhlalu.

Bungaki ubuhlalu obubomvu obukhona?

Bungaki ubuhlalu obuluhlaza obukhona?

Bungaki ubuhlalu obuluhlaza okotshani obukhona?

Bungaki ubuhlalu obusawolintshi obukhona?

Bungaki ubuhlalu obunsomi obukhona?

Bungaki ubuhlalu sebubonke?



Bhala inombolo yobuhlalu emabhokisini afanele bese uyabuhlanganisa.

obubomvu	+	obuluhlaza okotshani	=	
obuphuzi	+	obupinki	=	
obusawolintshi	+	obuluhlaza okotshani	=	
obunsomi	+	obuluhlaza okotshani	=	
obunsundu	+	obuphuzi	=	



Qedela amaphethini.





Sebenzisa ubuhlalu ukugcwalisa emabhokisini.

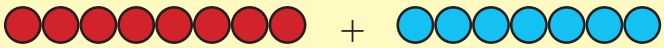 + = 15

8 + 7 =

 +  +  =

8 + 2 + 5 =

 +  =

9 + 6 =

 +  +  =

9 + ☐ + ☐ =

Qondanisa isithombe nesibalo bese unikeza impendulo.



7 − 5 = ☐



9 − 4 = ☐



8 − 3 = ☐



5 − 4 = ☐



6 − 2 = ☐

Bhala isibalo.



9 − 6 = 3



☐ − ☐ = ☐



☐ − ☐ = ☐



☐ − ☐ = ☐

Teacher:
Sign:
Date:





Usuku: _____

Izinsuku, amasonto kanye nezinyanga

uMsombuluko
uLwesibili
uLwesithathu
uLwesine
uLwesihlanu
uMgqibelo
iSonto

uMasingana	uNhlolanja	uNdasa
uMbasa	uNhlaba	uNhlangulana
uNtulikazi	uNcwaba	uMandulo
uMfumfu	uLwezi	uZibandlela



Phendula le mibuzo elandelayo mayelana namasonto.

Iluphi usuku olufika ngaphambili kukalwesithathu? _____

Iluphi usuku olufika emva kukalwesithathu? _____

Iluphi usuku olufika emva koMgqibelo? _____

Iluphi usuku oluphakathi koMsombuluko nolwesithathu? _____

Uma uMsombuluko uwusuku lokuqala kusho ukuthi ulwesihlanu usuku lwez_____

Iziphi izinsuku eziphakathi kukalwesithathu noMgqibelo?

_____



Phendula le mibuzo elandelayo mayelana nezinyanga.

Iyiphi inyanga efika phakathi kukaMbasa? _____

Iyiphi inyanga efika emva kukaNhlangulana? _____

Iyiphi inyanga ephakathi kukaNcwaba noMfumfu? _____

Iziphi izinyanga eziphakathi uMasingana noNhlangulana?

_____

Iyiphi inyanga yokuqala onyakeni? _____

Iyiphi inyanga yokugcina onyakeni? _____





Izinkolo eNingizimu Afrika



Izehlakalo ezinomlando

Usuku lwamalungelo abantu

Usuku lwenkululeko

Usuku lwabasebenzi

Usuku lwentsha

Usuku lukazwelonke lwabantu besifazane

Usuku lokubuyisana

Usuku lokuzalwa

Usuku lwami lokuzalwa





Okusikwayo kwesine: sebenzisa okusikwayo ukunamathisele ekhalendeni yezinyanga izinsuku ezintathu ezingcwele zenkolo kanye nawo wonke amaholide omphakathi waseNingizimu Afrika.

uMasingana	uNhlolanja	uNdasa
uMbasa	uNhlaba	uNhlangulana
uNtulikazi	uNcwaba	uMandulo
uMfumfu	uLwezi	uZibandlela



Teacher:

Sign:

Date:



Usuku:

Ukuhlanganisa

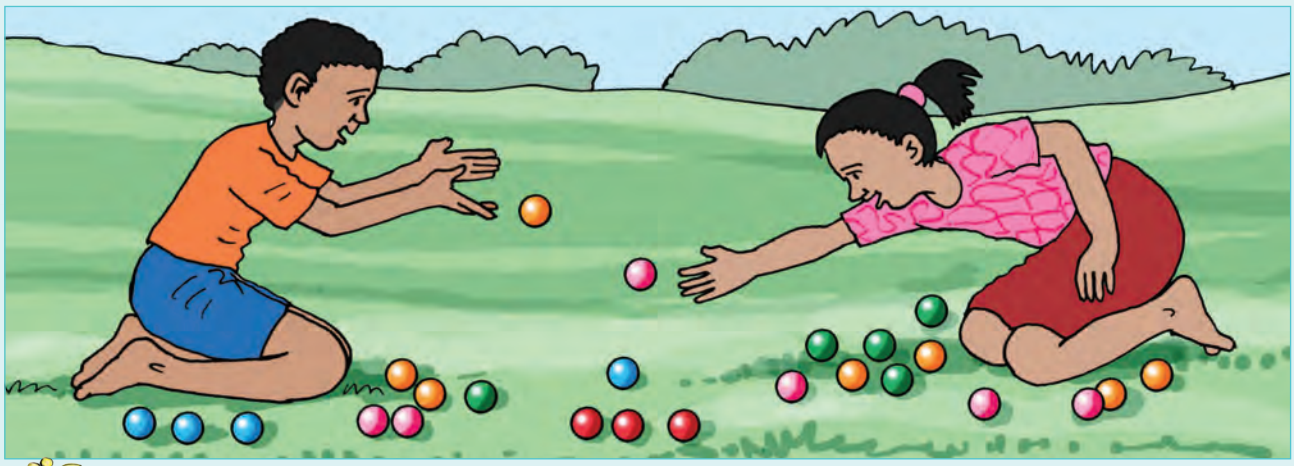

Buka isithombe bese uhlanganisa izimabuli.

ezibomvu	+	eziluhlaza	=	3	+	4	=	
eziluhlaza okotshani	+	eziluhlaza	=		+		=	
ezipinki	+	eziluhlaza	=		+		=	
eziluhlaza okotshani	+	ezisawolintshi	=		+		=	
ezibomvu	+	eziluhlaza okotshani	=		+		=	
ezisawolintshi	+	eziluhlaza	=		+		=	

Hlanganisa.

3 + 2 =	4 + 6 =	9 + 3 =
6 + 5 =	7 + 8 =	8 + 4 =
9 + 5 =	8 + 6 =	7 + 4 =
9 + 9 =	7 + 5 =	8 + 8 =
7 + 6 =	9 + 6 =	7 + 7 =



Yenza izinhlangothi zilingane.

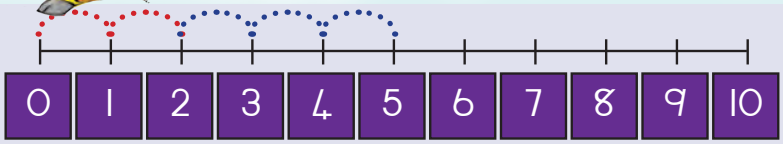

2 + 3 = 5

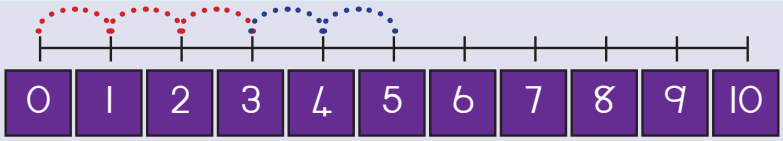

__ + __ = __

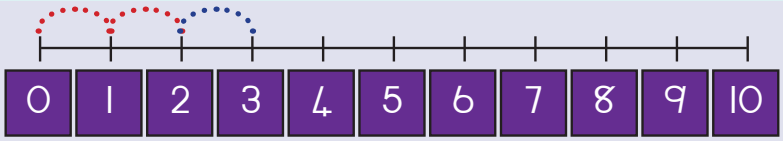

__ + __ = __

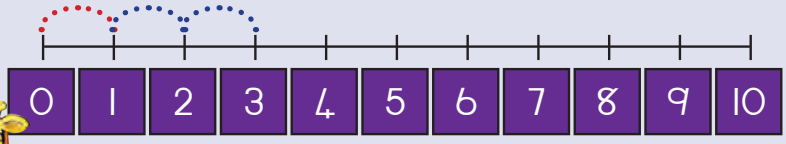

__ + __ = __

Enza izikeyili zilingane. Sikwenzele okokuqala.

5 = 1 + 4

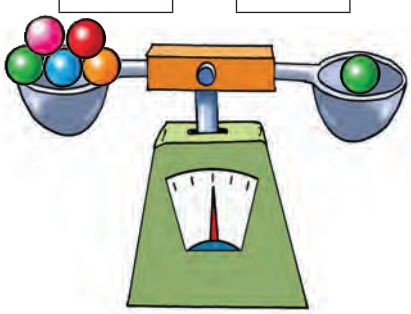

6 = 2 + __



3 + __ = __

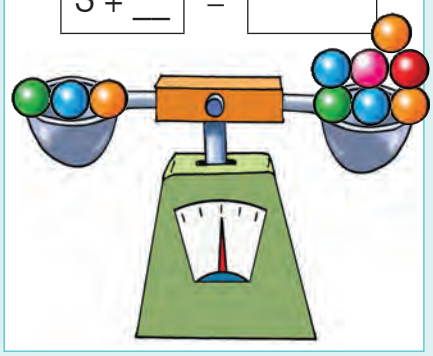

2 + 1 = 1 + __

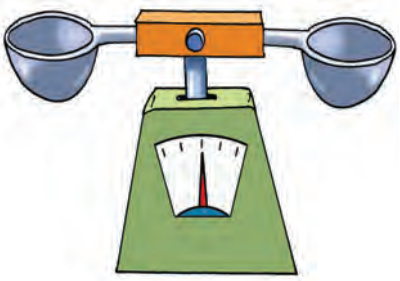

6 + 3 = 3 + __

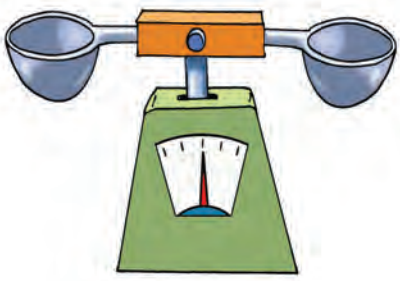

2 + __ = 8 + 2

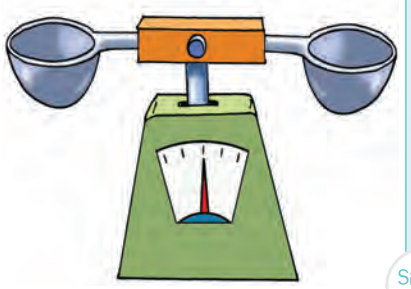

Teacher:

Sign:

Date:

23b

Usuku:

Ukususa

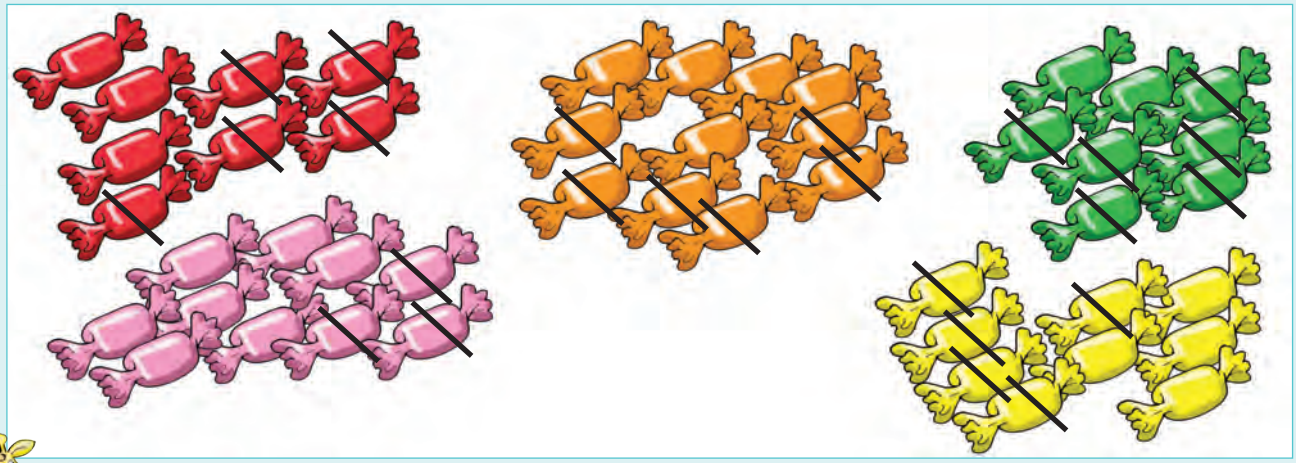



Buka isithombe bese ubhala izibalo ezisusayo.

Amaswidi abomvu	=	8	–	5	=	3
Amaswidi aluhlaza satshani	=		–		=	
Amaswidi aphuzi	=		–		=	
Amaswidi asawolintshi	=		–		=	
Amaswidi apinki	=		–		=	



Susa.

5 – 3 =	10 – 6 =	12 – 3 =
11 – 5 =	15 – 7 =	12 – 4 =
14 – 9 =	14 – 8 =	11 – 4 =
18 – 9 =	12 – 5 =	16 – 8 =
13 – 7 =	15 – 6 =	14 – 7 =





3 Qedela.

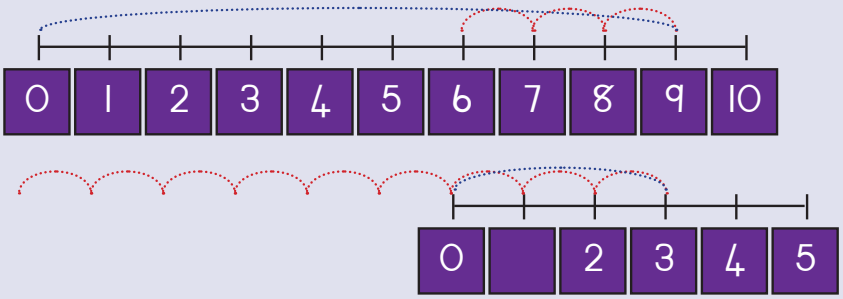

9 – 3

Akulingani no

3 – 9

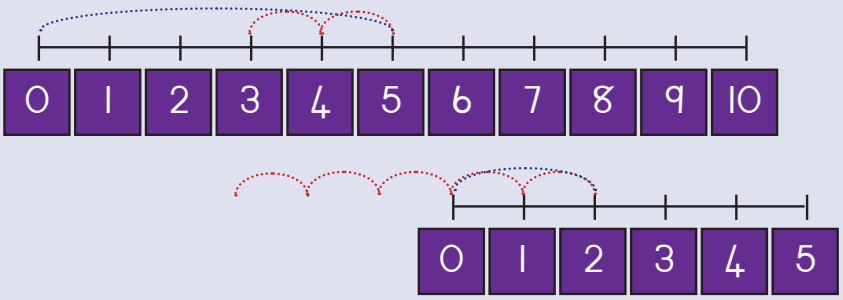

5 – 2

Akulingani no

2 – 5



Bhala isibalo salapha.



□ – □ = □

□ – □ = □



□ – □ = □



□ – □ = □



□ – □ = □

Teacher:

Sign:

Date:



Usuku:

Ukuhlanganisa (kuyaqhutshwa)

1 Qondanisa amakhadi

2 + 10	8 + 10	7 + 10	5 + 10	3 + 10
7 + 10 = 17	10 + 2 = 12	10 + 5 = 15	3 + 10 = 13	10 + 8 = 18

2 Sebenzisa umugqa wezinombolo. Bhala isibalo sokuhlanganisa. Sikwenzele okokuqala.

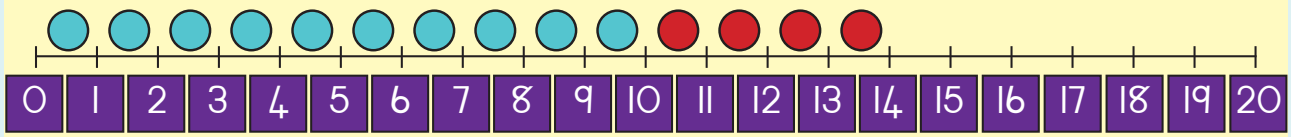

10 + 4 = 14

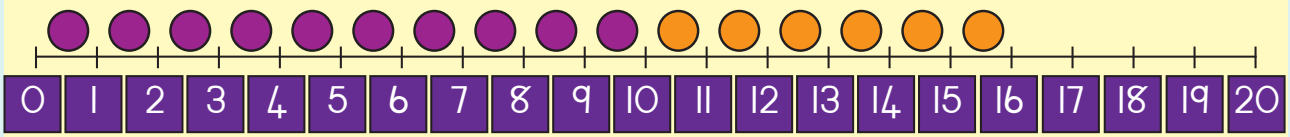

__ + __ = __

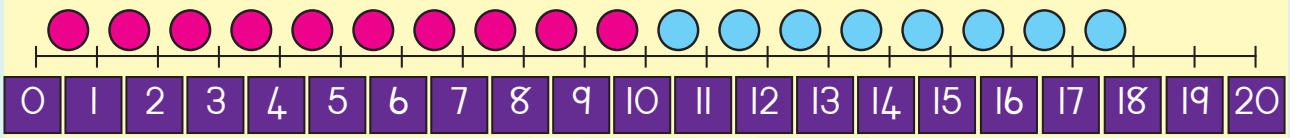

__ + __ = __

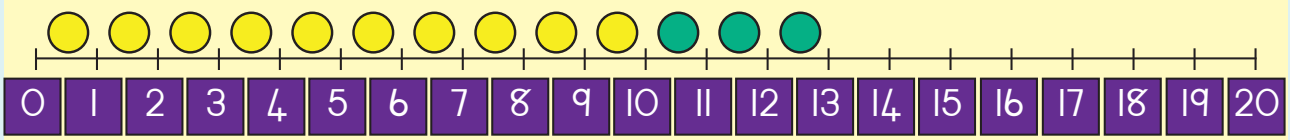

__ + __ = __







Hlanganisa.

10	+	3	=	13	10	+	2	=	
10	+	5	=		10	+	7	=	
10	+	1	=		10	+	6	=	
10	+	4	=		10	+	8	=	
10	+	9	=		10	+	3	=	



Hlanganisa.

16 + 13

10		10		20			
6	+	3	=	9			
16	+	13	=	29			

14 + 12

10		10					
4	+	2	=				
	+		=				

17 + 11

10		10					
7	+	1	=				
	+		=				

15 + 13

10		10					
5	+	3	=				
	+		=				

16 + 12

10		10					
6	+	2	=				
	+		=				

18 + 12

10		10					
8	+	2	=				
	+		=				



ULisa unezinto eziyisishiyagalolunye zokubala kanti uPeter yena uneziyisishiyagalombili.





Zingaki uma zizonke?

Teacher:

Sign:

Date:



Usuku:

Imali

1 Yini esebhange lami eliyingulubana?



2 Sika imali ewuhlweza kokubekelwe ukusikwa okunguNombolo 3 unamathisele amanani afanele lapha.

	
	
	



3 Mangaki amasenti?













4 Izibalo zamagama.

USuzi unama-50c. Umama wakhe umnike ama-20c ngaphezulu. Unamalini uSuzi?

_____

Nginama-90c. Ngithenge uswidi obiza ama-30c. Ngisele namalini?

_____

Teacher:
Sign:
Date:

11 12 13 14 15 16 17 18 19 20

Usuku: _____

Imali engamaphepha

1 Malini esesikhwameni sami semali?

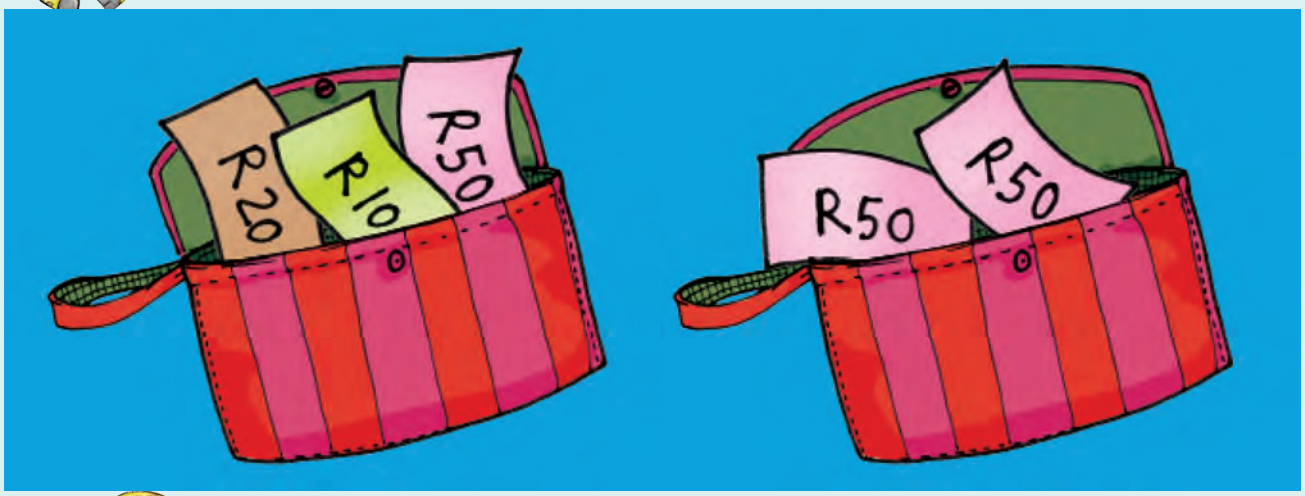

2 Sika imali engamaphepha kokubekelwe ukusikwa okungunombolo 3 unamathisele amanani afanele lapha.

	
	
	





Mangaki amaRandi?















Izibalo zamagama.

Ngonge amaR50. Ngithole amaR20 ngosuku lwami lokuzalwa. Nginamalini manje?

_____

Nginama-90. Ngithenge uswidi obiza ama-30c. Ngisele namalini?

_____

Teacher:
Sign:
Date:



Usuku:

Amaphethini



Shaya izandla ngephethini.

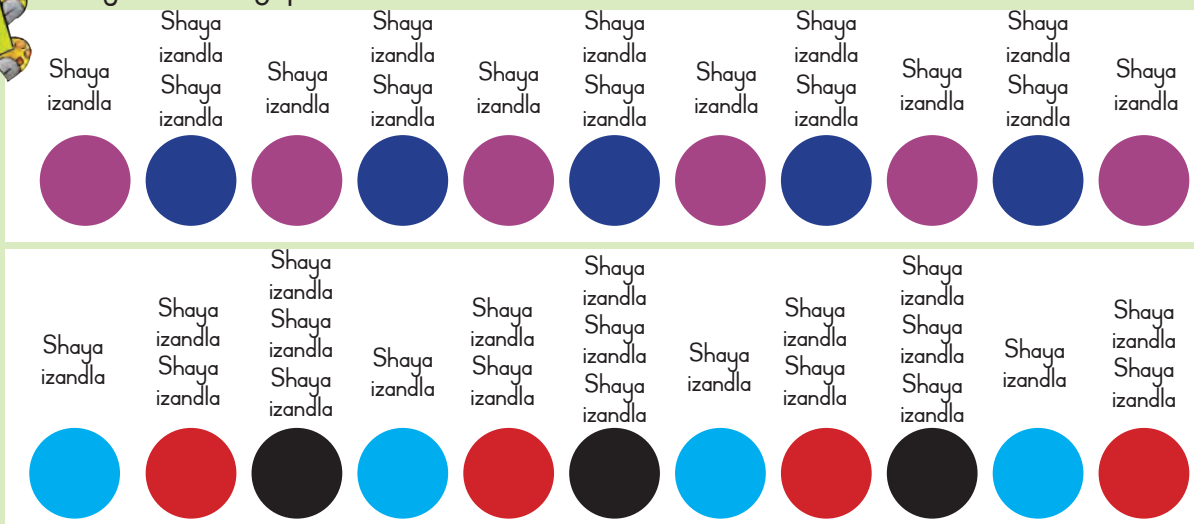



Kopisha amaphethini. Sebenzisa okusikwayo kwesithathu okubhalwe "Okusikwa Kukho 4" ekugcineni kwencwadi.

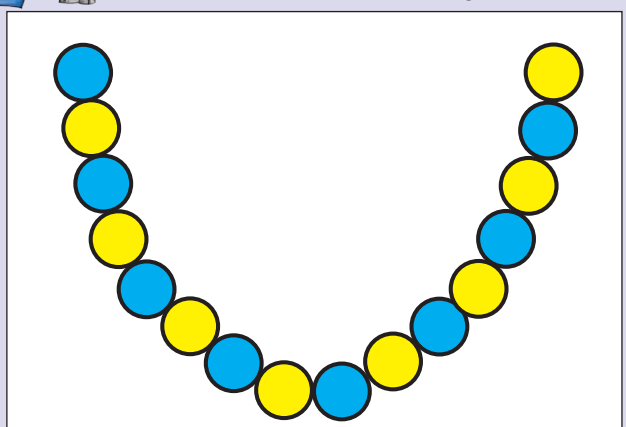



Yenza esakho isithombe ngobuhlalu obusalile. Sebenzisa okusikwayo 4.



Kopisha lawa maphethini alandelayo.

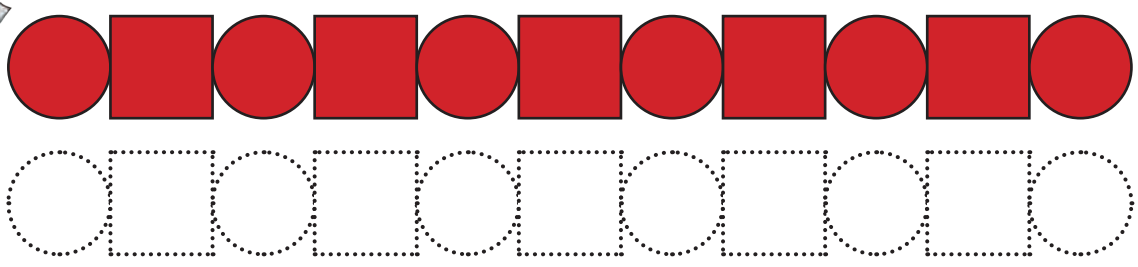



Kopisha amaphethini.





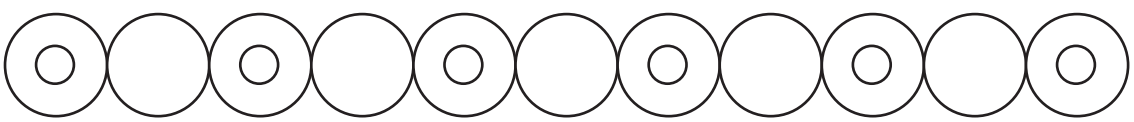

Teacher:

Sign:

Date:

11 12 13 14 15 16 17 18 19 20

Usuku:

Amaphethini

1

Chaza iphethini ngayinye ngamagama. Amagama angezansi angakusiza.



Isikwele | Unxantathu | Indilinga | Onxande | Imibala

2

Faka umbala kuphethini elandelayo.



3

Dweba iphethini elandelayo.



4

Nweba iphethini.

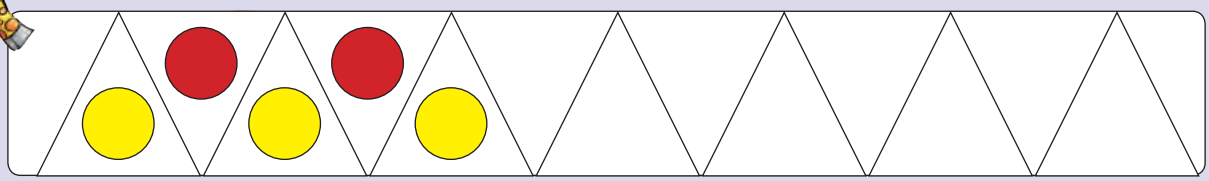



Dweba amaphethini akho usebenzise lokhu 

Dweba iphethini elandelayo.

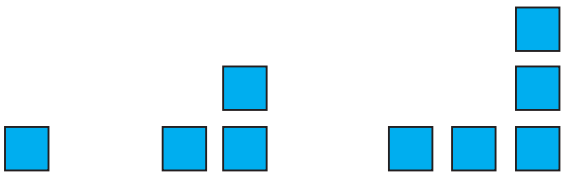



Qedela lokhu okulandelayo ukuze ube nendilinga eyodwa ngenhla.

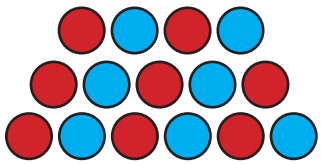

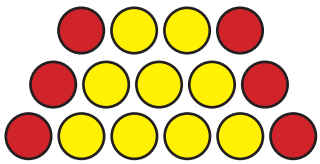



Zenzele awakho amaphethini emibala usebenzise izimo ezingezansi.

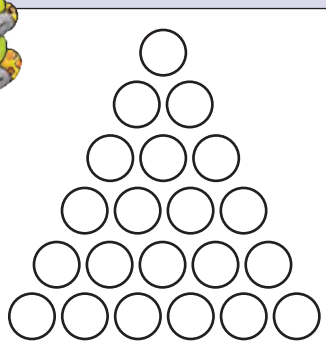

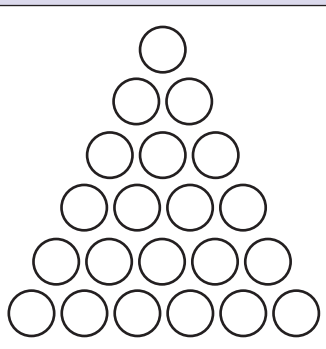

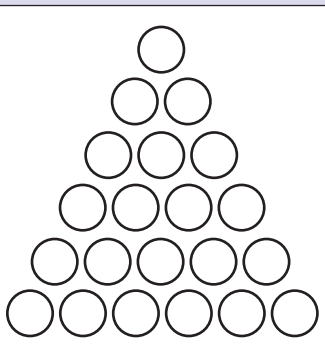

Teacher:
Sign:
Date:

11 12 13 14 15 16 17 18 19 20

Usuku:

Ukuphindaphinda: x 2

Mangaki amaswidi asetafuleni ngalinye?



Uwabala kanjani amaswidi?
Abanye abantwana bazothi 1, 2, 3... abanye bathi 2, 4, 6...)

Qedela lokhu okulandelayo: Sikwenzele okokuqala.

Amaqembu amane okungakubili	2 + 2 + 2 + 2 = 8	4 × 2 = 8
Amaqembu amahlanu okungakubili	2 + 2 + 2 + 2 + 2 =	5 × 2 =
Amaqembu ayisithupha okungakubili	2 + 2 + 2 + 2 + 2 + 2 =	6 × 2 =
Amaqembu ayisikhombisa okungakubili	2 + 2 + 2 + 2 + 2 + 2 + 2 =	7 × 2 =
Amaqembu ayisishiyagalombili okungakubili	2 + 2 + 2 + 2 + 2 + 2 + 2 + 2 =	8 × 2 =

Dweba lokhu okulandelayo.

Amaqembu amathathu okungakubili	Amaqembu amane okungakubili	Amaqembu ayisishiyagalolunye okungakubili



Dweba lokhu okulandelayo.

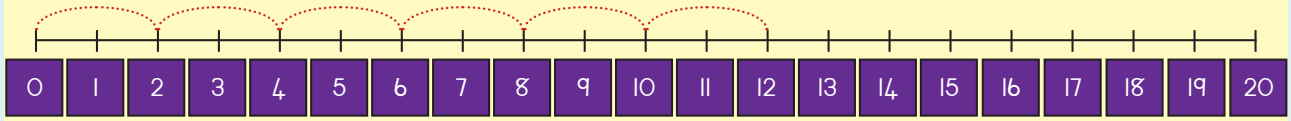

2, 4, 6, 8, ___ , ___

2 + 2 + 2 + 2 + 2 + 2 = ☐

6 × 2 = ☐

Umdwebo



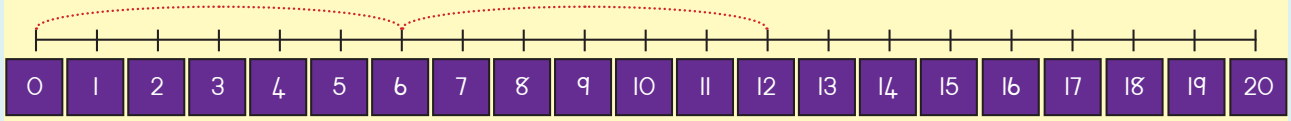

6, ___

6 + ☐ = ☐

2 × ☐ = ☐

Umdwebo



Isicabucabu esisodwa sinamehlo amabili. Izicabucabu eziyisikhombisa zinamehlo amangaki?

☐



2 4 6 8 10 12 14

16 18 20 22 24 26

Teacher:

Sign:

Date:



Usuku: _____

Ukuphindaphinda: x 5

Mangaki amaswidi asetafuleni ngalinye?



Qedela lokhu okulandelayo. Sikwenzele okokuqala.



Amaqembu amathathu okungakuhlanu	5 + 5 + 5 = 15	3 × 5 = 15
Amaqembu amabili okungakuhlanu	5 + 5 =	2 × 5 =
Amaqembu amane okungakuhlanu	5 + 5 + 5 + 5 =	4 × 5 =
Amaqembu ayisithupha okungakuhlanu	5 + 5 + 5 + 5 + 5 + 5 =	6 × 5 =
Amaqembu ayisikhombisa okungakuhlanu	5 + 5 + 5 + 5 + 5 + 5 + 5 =	7 × 5 =

Dweba lokhu okulandelayo.

Amaqembu amathathu okungakuhlanu	Amaqembu amane okungakuhlanu	Amaqembu ayisihlanu okungakuhlanu





Dweba lokhu okulandelayo.

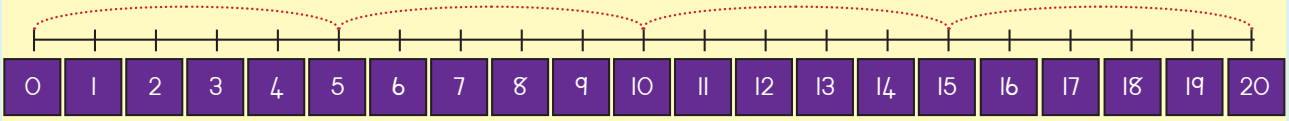

5, 10, 15, ___

5 + 5 + 5 + 5 = ☐

4 × 5 = ☐

Umdwebo

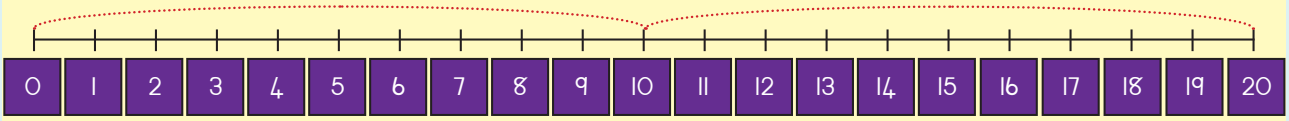

10, ___

10 + ☐ = ☐

10 × ☐ = ☐

Umdwebo



5 10 15 20 25 30

35 40 45 50

Teacher:

Sign:

Date:



Usuku:

Ezinye izindaba zokuphindaphinda

Yenza eyakho indaba usebenzise inani lezindlebe, izandla kanye nezinyawo.



Singabangani abayi-10. Sinezandla ezingaki?

Yenza umdwebo.

Kukhombise ngezinto zokubala.

Kukhombise emgqeni wezinombolo.

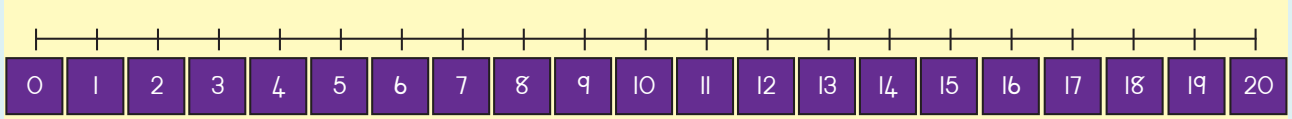

\+ = × =







Umndeni kaSusan unezicathulo eziyishumi. Banezicathulo ezingaki?

Yenza umdwebo.

Kukhombise ngezinto zokubala

Kukhombise emgqeni wezinombolo.

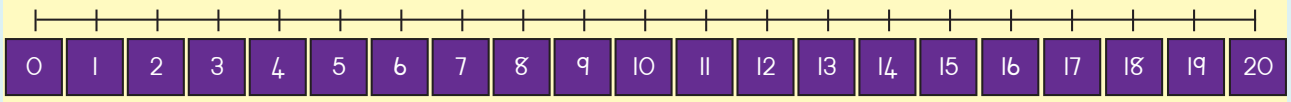



+ = × =

Bhala eyakho indaba usebenzise izingane eziyi-6 kanye nezandla zazo.



5 10 15 20 25 30 35

Teacher:
Sign:
Date:



11 12 13 14 15 16 17 18 19 20

Usuku:

Izikwele, onxande, onxantathu nezindilinga (kuyaqhubeka)



Faka umbala obomvu kuwo wonke amabhola, oluhlaza emabhokisini kanye noluhlaza okotshani kumasilinda.

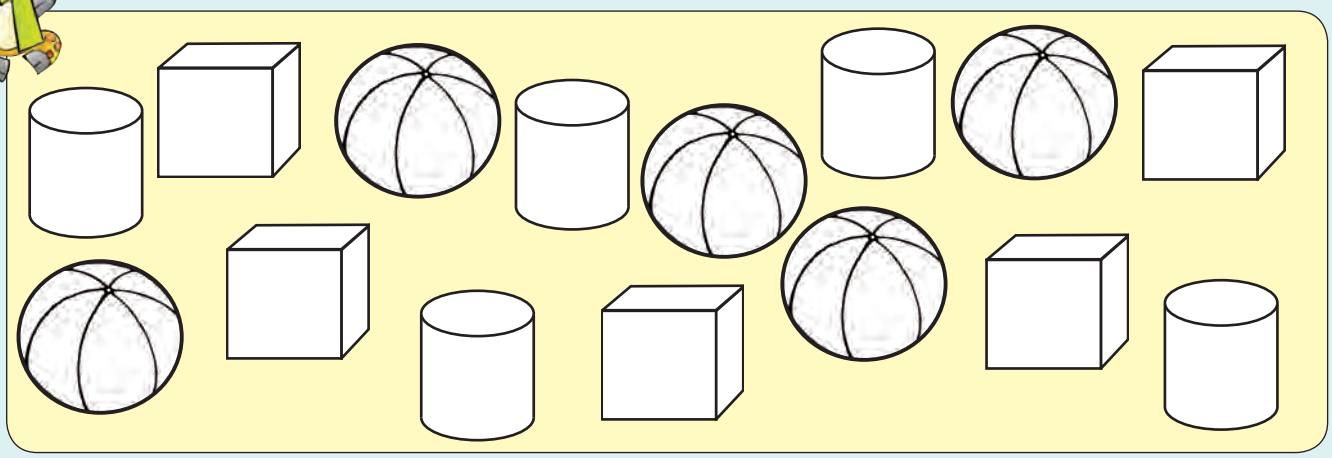

Khetha igama elifanele.



izinqenqema eziqondile

izinqenqema ezimagwinci

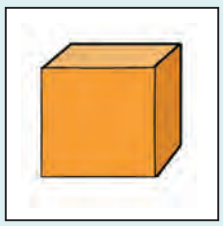

izinqenqema eziqondile

izinqenqema ezimagwinci



izinqenqema eziqondile

izinqenqema ezimagwinci



Isho ukuthi le nto izogingqika noma izoshibilika.



gingqika

shibilika

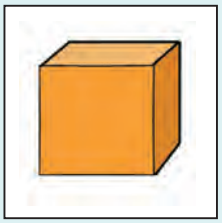

gingqika

shibilika



gingqika

shibilika

Ubona ezingaki kulezi zinto esithombeni: amasilinda, amabhokisi namabhola?





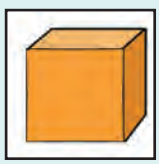



Dweba esakho isithombe usebenzise amabhola, amabhokisi kanye namasilinda.



Usuku:

Landelanisa bese uqhathanisa lezi zinombolo: 1–40

Ubani onamawolintshi amaningi?





Ubani onama-apula amaningi?





Bala ubuhlalu bese ugcwalisa amabhokisi angenalutho.

1	2	3	4	5		7			10
	12				16		18		
21				25	26				30
31					36				40

Bheka ubuhlalu bese uphendula imibuzo.

Iyiphi inombolo engaphambi kuka-8? ____

Iyiphi inombolo elandela u-13? ____

Iyiphi inombolo engaphambi kuka-20? ____

Iyiphi inombolo engaphambi kuka-24? ____





Faka umbala oluhlaza ezinombolweni ezincane kuno-10 bese ufaka obomvu kwezinkulu kuno-10.

1	2	3	4	5	6	7	8	9	10
11	12	13	14	15	16	17	18	19	20

Faka umbala oluhlaza ezinombolweni ezincane kuno-30 kodwa ezinkulu kuno-24.

20	21	22	23	24	25	26	27	28	29	30

Faka umbala ophuzi ezinombolweni eziphelele bese ufaka oluhlaza okotshani ezinombolweni ezilugweje.

30	31	32	33	34	35	36	37	38	39	40

Iyiphi inombolo elugweje eza emva kuka-15.

1	2	3	4	5	6	7	8	9	10
11	12	13	14	15	16	17	18	19	20
21	22	23	24	25	26	27	28	29	30
31	32	33	34	35	36	37	38	39	40
41	42	43	44	45	46	47	48	49	50



Iyiphi inombolo engelona ugweje eza ngaphambi kuka-10?	
Iyiphi inombolo engelona ugweje eza ngaphambili kuka-10?	
Bhala phansi izinombolo ezingelona ugweje eziphakathi kuka-14 no-28.	
Bhala phansi izinombolo ezilugweje eziphakathi kuka-5 no-15?	
Iyiphi inombolo elugweje eza emva kuka-21?	
Iyiphi inombolo engelona ugweje eza ngaphambili kuka-24?	
Bhala phansi izinombolo ezingelona ugweje eziphakathi kuka-20 kanye no-30?	
Bhala phansi izinombolo ezilugweje eziphakathi kuka-20 kanye no-30?	

Teacher:
Sign:
Date:



Usuku:

Hlela bese uyaqhathanisa: 40–50

Ubani onophayinaphu abaningi?





Bala ubuhlalu bese ugcwalisa amabhokisi angenalutho.

1	2	3	4	5					
								19	
							28		

	32								
									50
51	52	53	54	55	56	57	58	59	60

Buka ubuhlalu bese uphendula imibuzo.

Iyiphi inombolo encane kuno-31?

Iyiphi inombolo enkulu kuno-31?

Iyiphi inombolo encane kuno-38?

Iyiphi inombolo encane kuno-47?





Faka umbala oluhlaza okotshani ezinombolweni ezincane kunama-40 kanye nezinkulu kunama-36.

30	31	32	33	34	35	36	37	38	39	40

Izinombolo ezincane kunama-40.

Izinombolo ezinkulu kunama-36.



Faka umbala ophuzi ezinombolweni eziphelele bese ufaka oluhlaza okotshani kwezilugweje.

40	41	42	43	44	45	46	47	48	49	50

Iyiphi inombolo elugweje eza emva kuka-40?

Iyiphi inommbolo ephelele eza ngaphambili kuka-43?

Bhala phansi izinombolo eziphelele eziphakathi kuka-40 no-50?

Bhala phansi izinombolo ezilugweje eziphakathi kuka-40 no-50?

Izinombolo ezimbili ezincane kuno-40

Izinombolo ezimbili ezinkulu kuno-41



Teacher:

Sign:

Date:





Usuku: _____

Izinombolo ama-40 kuya kuma-50



Ubala ubuhlalu obungaki?

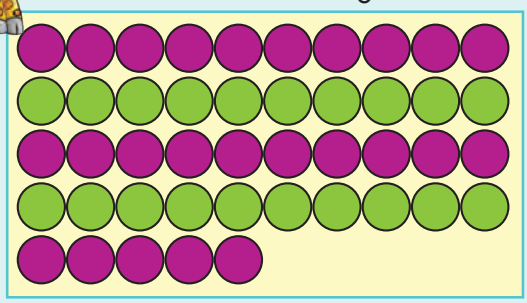

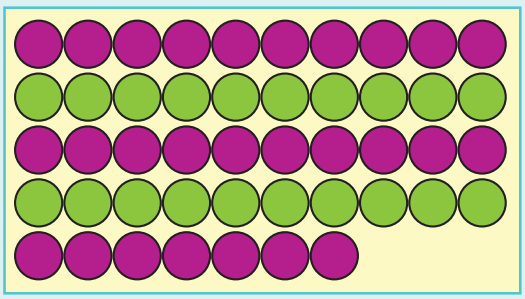

Inombolo	Singayibhala kanje.	Inombolo	Singayibhala kanje.
45	40 + 5 = 45		+ =

Qedela lokhu okulandelayo.

20	21	22							
30				34					
		42							

Qedela lokhu okulandelayo.



20 +  4 = 2 4



+  =





Bhala amagama.

41	_____	42	_____
43	_____	44	_____
45	_____	46	_____
47	_____	48	_____
49	_____	50	_____



Bheka isibonelo sokuqala bese uqedela okulandelayo.

45	=	4	amashumi	+	8	imivo
43	=		amashumi	+		imivo
42	=		amashumi	+		imivo

44	=		amashumi	+		imivo
41	=		amashumi	+		imivo
48	=		amashumi	+		imivo



Bhala inombolo kukholomu efanele.

	Amashumi	Imivo
27		
34		
46		
41		
39		



Teacher:
Sign:
Date:





Usuku:

Izikwele, onxande, onxantathu kanye nezindilinga



Ugogo wenze leli tshali elihle. Khomba yonke imimo.

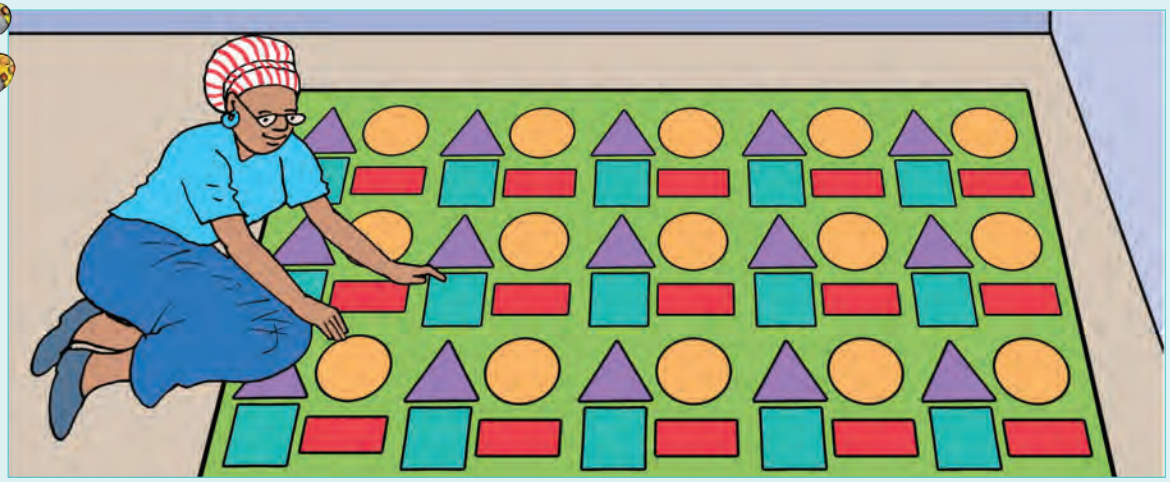



Faka umbala oluhlaza ezikweleni, ophuzi konxande, oluhlaza okotshani konxantathu kanye nobomvu ezindilingeni.

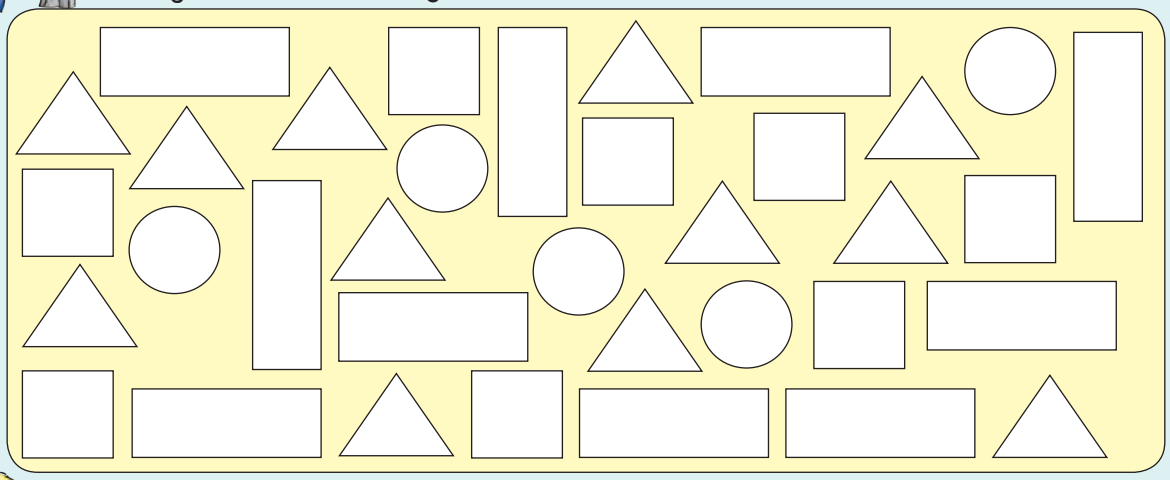



Khetha impendulo efanele.



inqenqema eqondile

inqenqema eyindilinga



inqenqema eqondile

inqenqema eyindilinga



inqenqema eqondile

inqenqema eyindilinga



inqenqema eqondile

inqenqema eyindilinga



Zingaki izimo ezinje kanye nezinje ozibalayo?



Dweba isithombe sakho usebenzise izindilinga, izikwele, onxantathu kanye nonxande.

Teacher:
Sign:
Date:

11 12 13 14 15 16 17 18 19 20

Usuku:

Imisebenzi ehlanganisiwe 1–20



Ukukhumbula ngokushesha.

4 + 5 – 1 =	13 – 9 + 2 =	20 – 7 + 1 =	10 + 5 – 4 =
10 + 3 + 2 =	9 + 3 – 2 =	8 – 2 – 1 =	13 – 8 + 1 =
9 – 4 – 3 =	18 – 9 – 4 =	7 + 8 + 1 =	16 – 7 + 3 =
14 – 6 + 4 =	12 – 5 – 2 =	19 – 10 + 5 =	6 + 5 – 3 =



Hlanganisa lokhu okulandelayo.

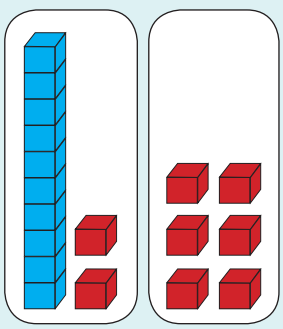

= 10 2 + 6

= 10 + 8

= 18

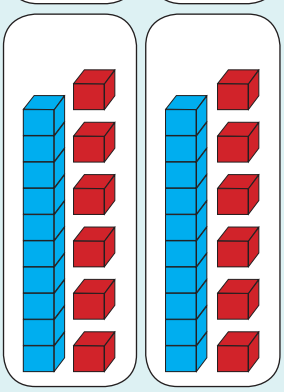

= + + =

= + =

= + =

=

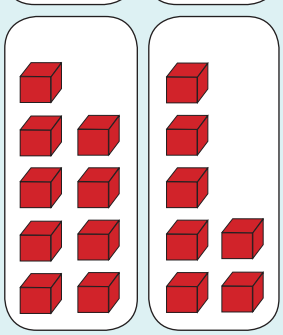

= + =

= + =

=





Susa lokhu okulandelayo.

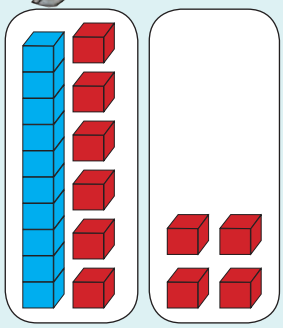

= 10 6 − 4

= 10 − 2

= 8

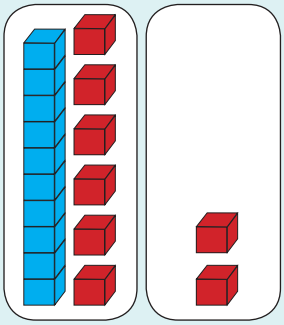

= ☐ ☐ + ☐ ☐

= ☐ − ☐

= ☐

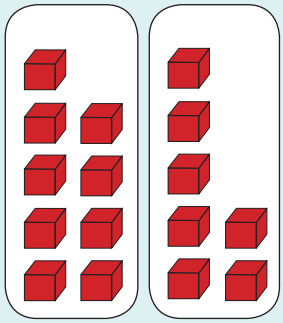

= ☐ − ☐

= ☐



Ngithenge amaswidi ayi-15. Ngadla amabili.
Nganika umngani wami amane. Ngisele namaswidi amangaki?



Teacher:

Sign:

Date:



Usuku: _____

Imisebenzi ehlanganisiwe 20–50



Ukukhumbula ngokushesha.

20 + 2 – 1 =	36 – 6 + 2 =	42 – 2 + 4 =	47 + 4 – 1 =
30 + 3 + 6 =	42 + 9 – 1 =	33 – 2 – 1 =	49 – 1 + 2 =
55 – 5 – 0 =	38 – 7 – 1 =	45 + 1 + 2 =	50 – 5 + 3 =
24 – 3 + 2 =	32 – 5 – 2 =	49 – 10 + 1 =	29 + 5 – 4 =



Hlanganisa lokhu okulandelayo.

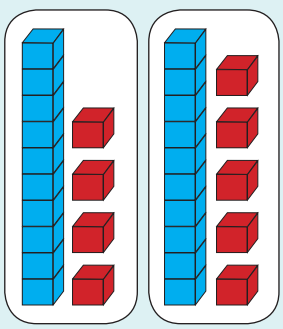

= ☐ ☐ + ☐ ☐

= ☐ + ☐

= ☐

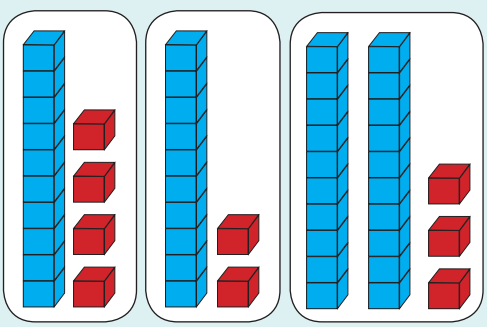

= ☐ ☐ + ☐ ☐ + ☐ ☐

= ☐ + ☐

= ☐

Ake uzame eyakho indlela.





3 Susa lokhu okulandelayo.

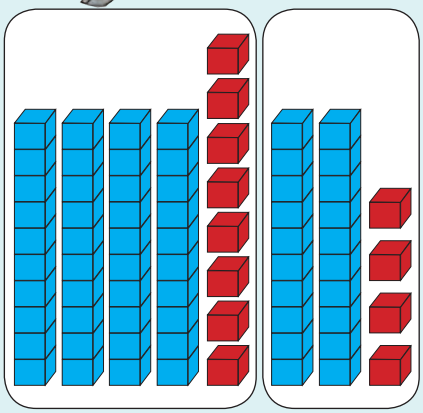

= 40 8 − 20 4

= 40 − 20 + 8 − 4

= ☐ − ☐

= ☐

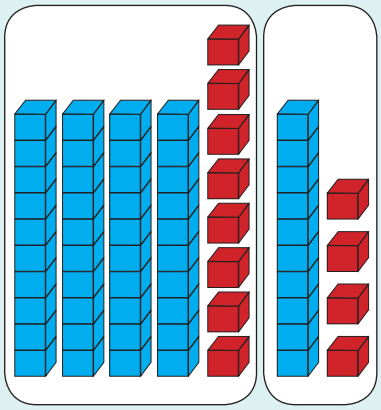

= ☐ ☐ − ☐ ☐

= ☐ − ☐ + ☐ − ☐

= ☐ − ☐

= ☐

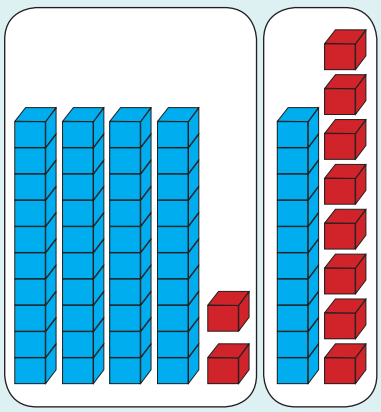

= ☐ ☐ − ☐ ☐

= ☐ − ☐ + ☐ − ☐

= ☐ − ☐

= ☐



4 Nginephepha eliyi R10, uhlweza luka R5, iphepha lika R2 ebhange lami eliyingulube. Ngonge malini?

R20 R5 R2 R10

Teacher:
Sign:
Date:



Usuku:

Okunye ukuhlanganisa



Kungaki uma kukonke okusebheleni ngalinye?

1 10 5 10	2 10 6 20	3 20 5 20	4 20 4 10



Qedela.

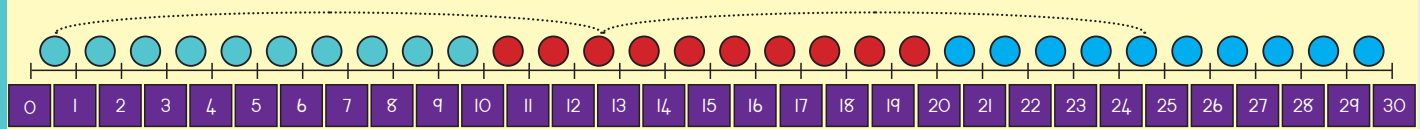

13 + 12 =

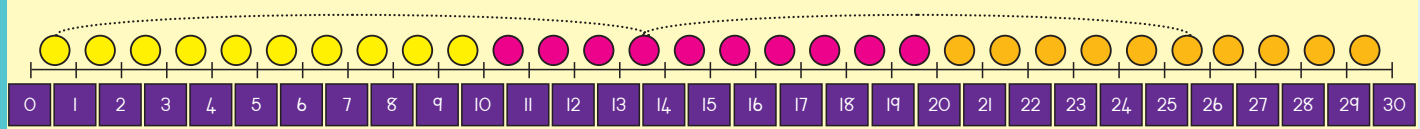

14 + 12 =

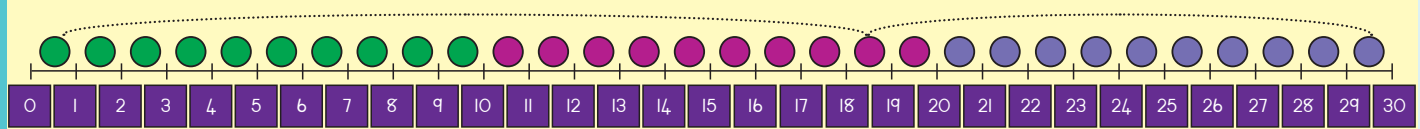

19 + 11 =

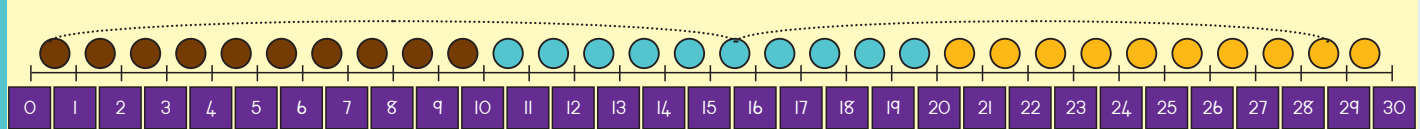

16 + 13 =

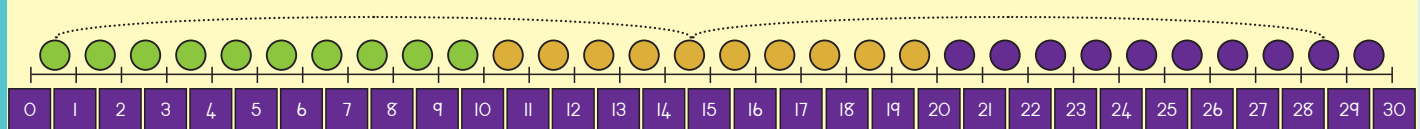

15 + 14 =





Qedela.

12 + 11

= 10 2 + 10 1

= 10 + 10 + 2 + 1

= 20 + 3

= 23

13 + 15

= ☐☐ + ☐☐

= ☐ + ☐ + ☐ + ☐

= ☐ + ☐

= ☐

26 + 12

= ☐☐ + ☐☐

= ☐ + ☐ + ☐ + ☐

= ☐ + ☐

= ☐

23 + 22

= ☐☐ + ☐☐

= ☐ + ☐ + ☐ + ☐

= ☐ + ☐

= ☐

24 + 13

= ☐☐ + ☐☐

= ☐ + ☐

= ☐

35 + 12

= ☐☐ + ☐☐

= ☐ + ☐

= ☐

UBetty uthenge amaswidi ngo-R36, uSipho wathenga aka-R13. Basebenzise malini seyiyonke emaswidini?

Teacher:

Sign:

Date:

11 12 13 14 15 16 17 18 19 20

Usuku:

Ukuhlanganisa (kuyaqhutshwa)



Kungaki uma kukonke okusebheleni ngalinye?

12 + 10 = ☐

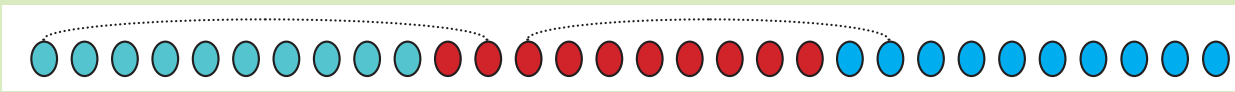

15 + 10 = ☐

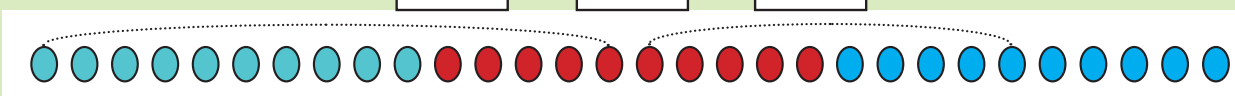

19 + 10 = ☐

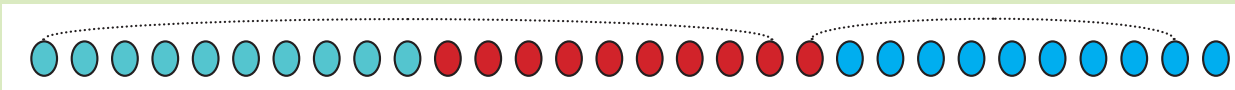



Dweba ubuhlalu obusele bese uqedela isibalo.

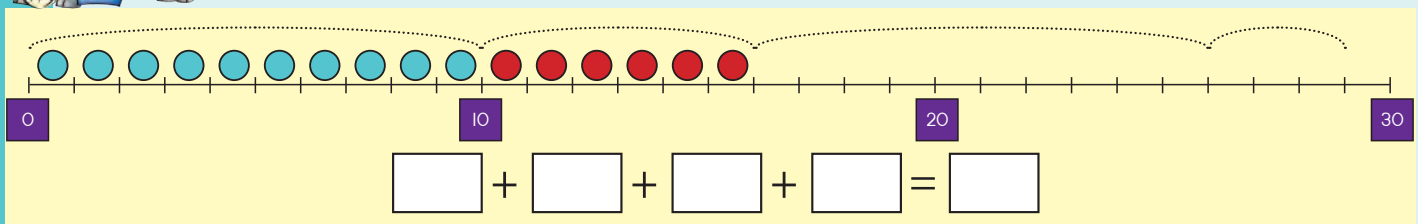

☐ + ☐ + ☐ + ☐ = ☐

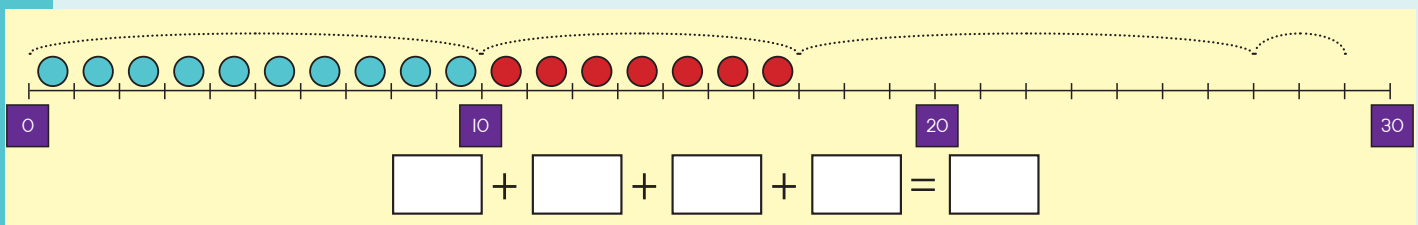

☐ + ☐ + ☐ + ☐ = ☐

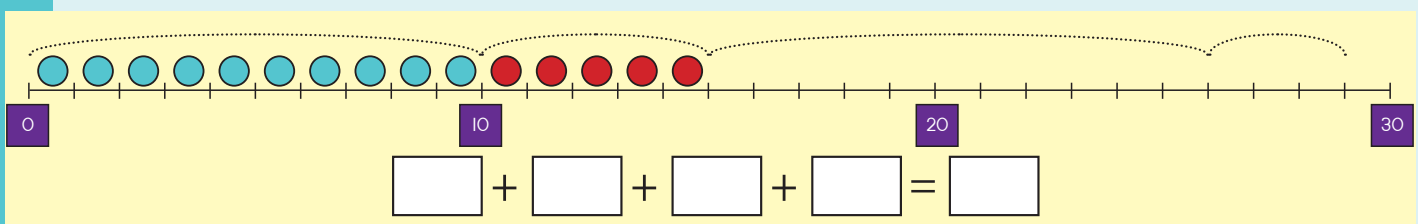

☐ + ☐ + ☐ + ☐ = ☐

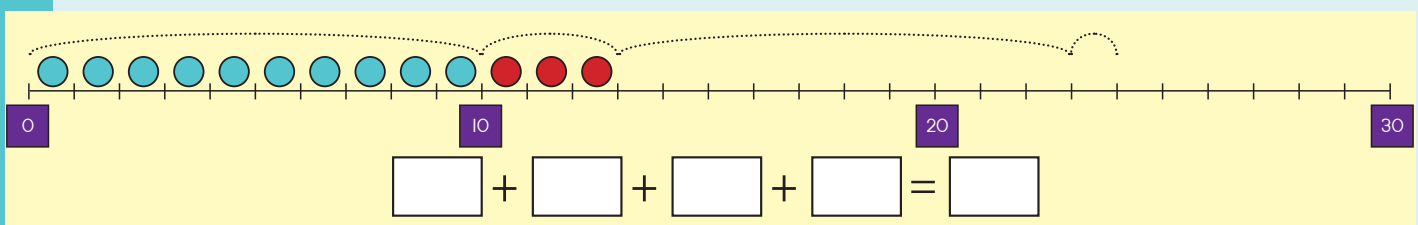

☐ + ☐ + ☐ + ☐ = ☐



Qedela.

28	+	11	=	2	8	+	10	+	1	=	38	+	1	=	39
34	+	12	=	3	4	+	10	+	2	=		+		=	
23	+	13	=	2	3	+	10	+	3	=		+		=	
35	+	12	=	3	5	+	10	+	2	=		+		=	
26	+	11	=	2	6	+	10	+	1	=		+		=	



Hlanganisa.

11 + 10 =		23 + 10 =		36+ 10 =	
28 + 10 =		37 + 10 =		12 + 10 =	
34 + 10 =		29 + 10 =		15 + 10 =	



Inani lokuyisi-7 nokuyisi-6 lenza oku?
Dweba isithombe ukukhombisa impendulo yakho.



Thola isibalo (inani) samagama usebenzise izithombe.





Teacher:
Sign:
Date:

Usuku:

Ubude



Kujana

Faka umbala wezimpendulo ufane nowamabhokisi.

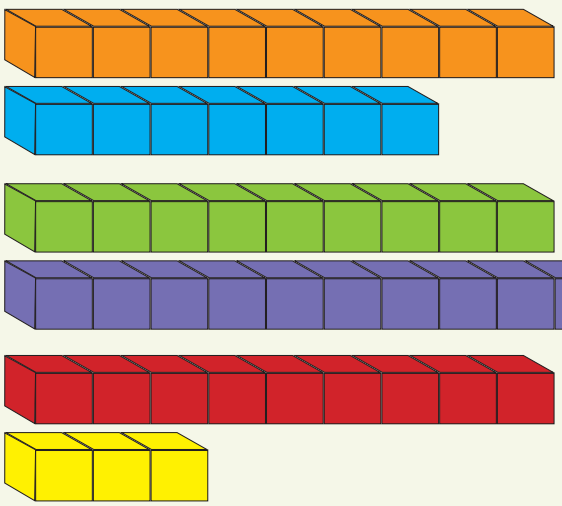

kufushane | Kujana

kufushane | Kujana

kufushane | Kujana

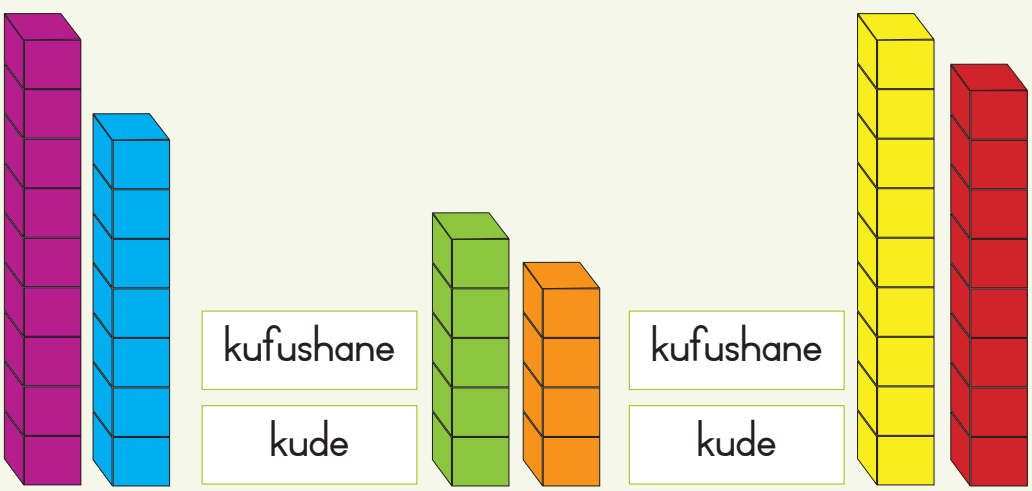

kufushane | kufushane | kufushane

kude | kude | kude

1 2 3 4 5 6 7 8 9 10



2 Faka umbala wempendulo ufane nowesikhindi somfana.



mfushane | mude



mude | mfushane



mfushane | mude



3 Kala amacala endawo yokudlala ngesandla kanye nonyawo ukuthathe endaweni yokusika yokuqala.

Ilingana nezandla ezingaki ubude indawo yokudlala?

Ilingana nezinyawo ezingaki ubude indawo yokudlala?

ubude



Teacher:
Sign:
Date:

Usuku:

Ukususa (kuyaqhutshwa)

1 Qondanisa amakhadi

10	10	10	10	10
2 2	8 8	7 7	5 5	3 3
17 – 7 = 10	12 – 2 = 10	15 – 5 = 10	13 – 3 = 10	18 – 8 = 10

2 Sebenzisa umugqa wezinombolo. Bhala isibalo sokususa.

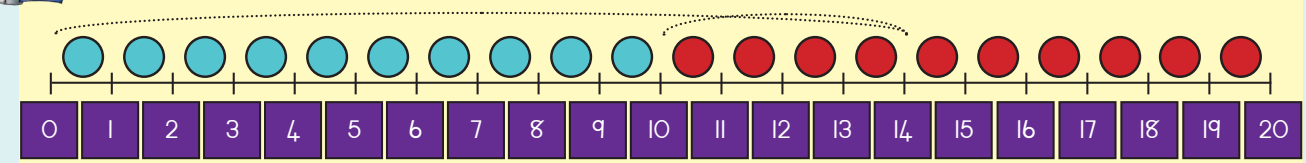

14 – 4 = 10

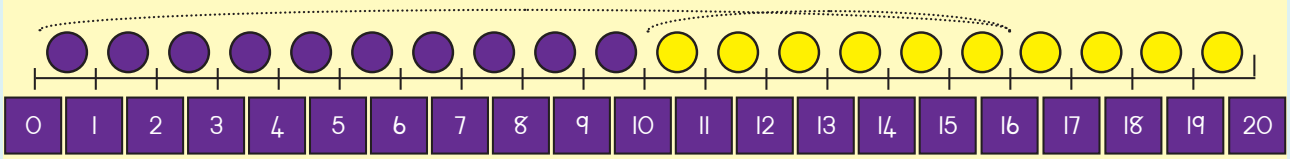

__ – __ = __

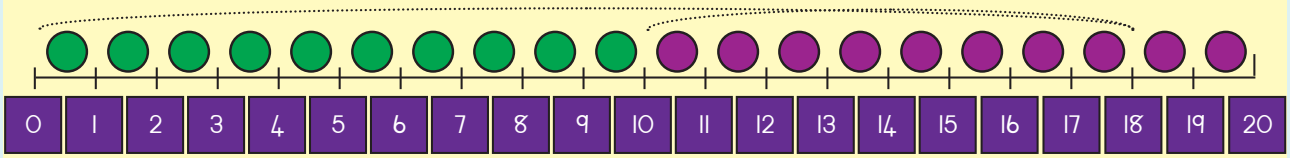

__ – __ = __

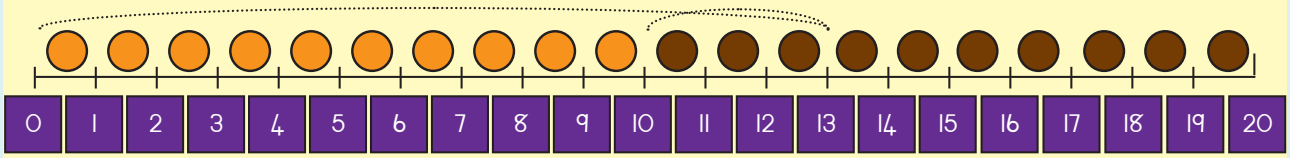

__ – __ = __





Hlanganisa.

10	3	−	3	=		10	2	−	2	=	
10	5	−	5	=		10	7	−	7	=	
10	1	−	1	=		10	6	−	6	=	
10	4	−	4	=		10	8	−	8	=	
10	9	−	9	=		10	9	−	5	=	



Hlanganisa.

16 − 13

10	10		0		
6		3		3	
16	−	13	=	3	

14 − 12

10	10				
4		2			
14	−	12	=		

27 − 11

20	10				
7		1			
	−		=		

35 − 13

30	10				
5		3			
	−		=		

26 − 12

20	10				
6		2			
	−		=		

48 − 11

40	10				
8		1			
	−		=		



ULisa unezinto eziyi-17 zokubala. Ulahle izinto zokubala eziyi-.





Usele nezinto ezingaki zokubala?

Teacher:

Sign:

Date:



11 12 13 14 15 16 17 18 19 20



Usuku:

Kuyasuswa Futhi

Susa izinombolo ezingezansi ezinombolweni ezingaphezulu.

10 − 7 = 17	20 − 2 =	30 − 8 =	40 − 9 =
10 − 5 = 15	10 − 1 =	10 − 5 =	10 − 4 =
2			

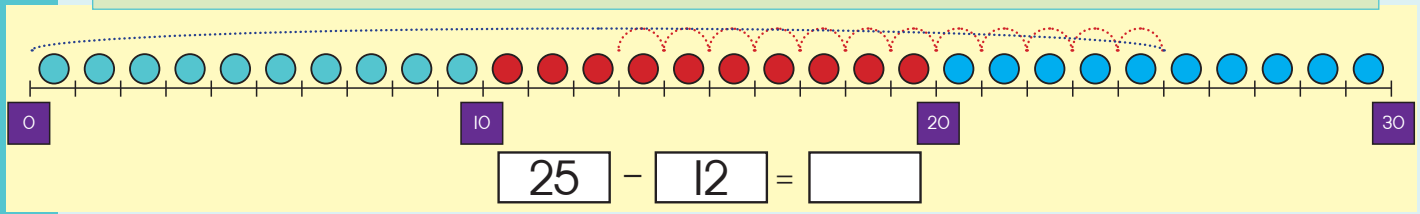

25 − 12 = ☐

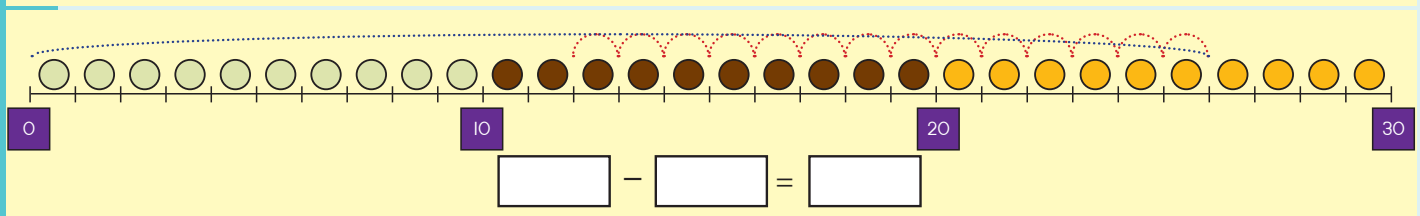

☐ − ☐ = ☐

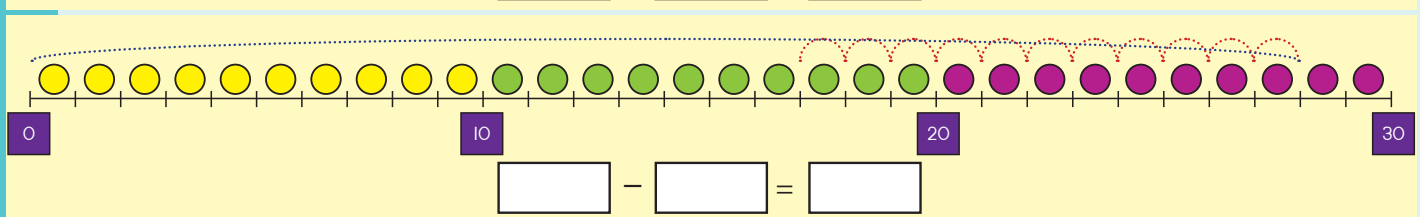

☐ − ☐ = ☐

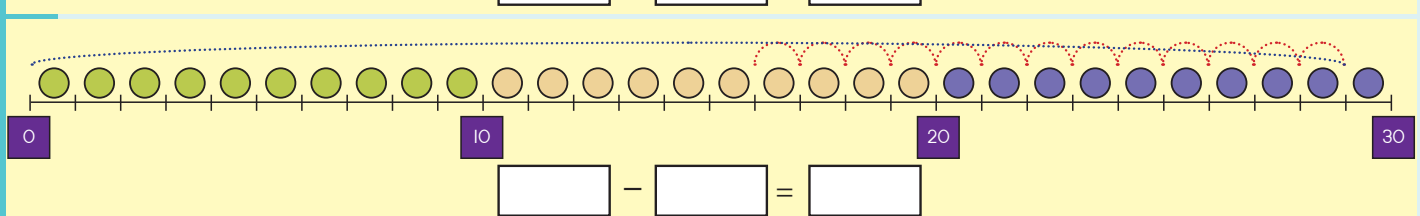

☐ − ☐ = ☐

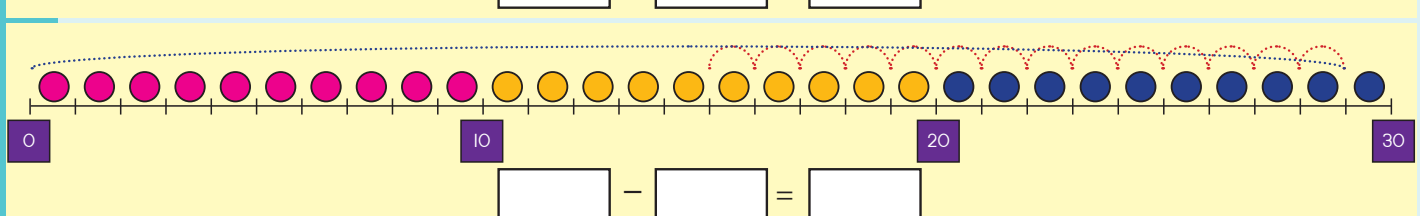

☐ − ☐ = ☐







Susa.

45 – 23

= 40 [ ] – 20 3

= 40 – 20 + 5 – 3

= 20 + 2

= 22

38 – 16

= [ ] [ ] – [ ] [ ]

= [ ] – [ ] + [ ] – [ ]

= [ ] + [ ]

= [ ]

29 – 14

= [ ] [ ] – [ ] [ ]

= [ ] – [ ] + [ ] – [ ]

= [ ] + [ ]

= [ ]

48 – 11

= [ ] [ ] – [ ] [ ]

= [ ] – [ ] + [ ] – [ ]

= [ ] + [ ]

= [ ]

35 – 23

= [ ] [ ] – [ ] [ ]

= [ ] – [ ] + [ ] – [ ]

= [ ] + [ ]

= [ ]

38 – 15

= [ ] [ ] – [ ] [ ]

= [ ] – [ ] + [ ] – [ ]

= [ ] + [ ]

= [ ]



Teacher:

Sign:

Date:



11 12 13 14 15 16 17 18 19 20

Usuku: _____

Ukususa (kusaqhutshwa)



Susa izinombolo ezingezansi ezinombolweni ezingaphezulu.

22 – 10 = ☐



25 – 10 = ☐

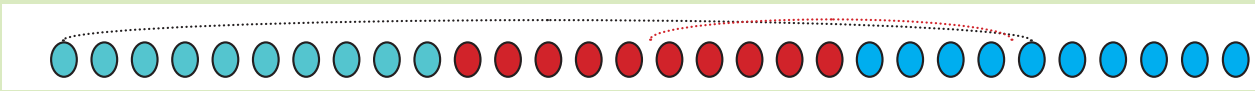

29 – 10 = ☐





Qedela ukubala.

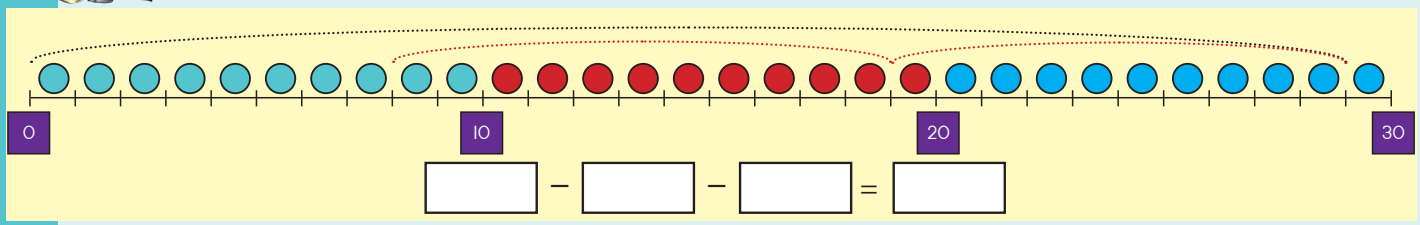

☐ – ☐ – ☐ = ☐

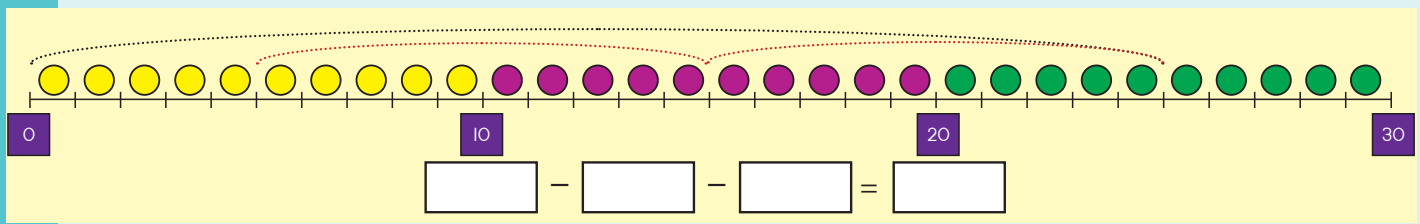

☐ – ☐ – ☐ = ☐

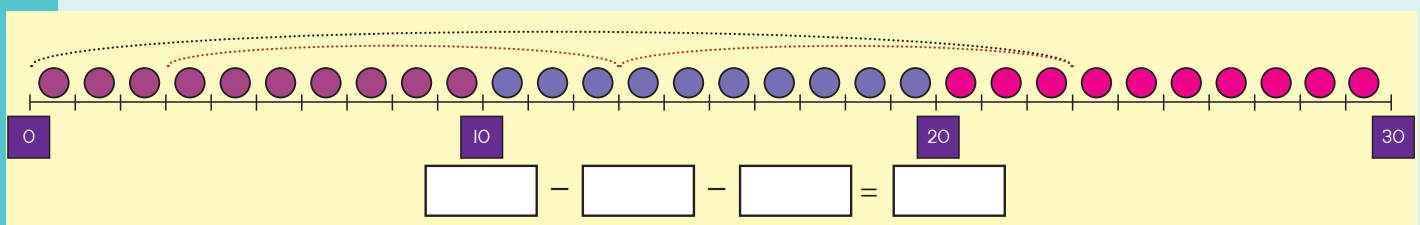

☐ – ☐ – ☐ = ☐

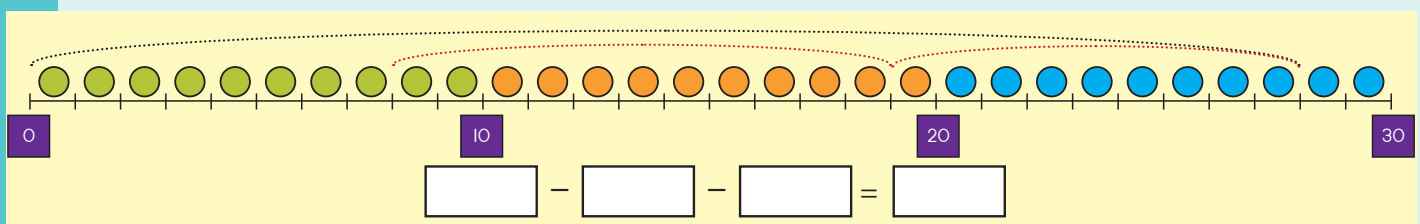

☐ – ☐ – ☐ = ☐







Qedela.

46 − 13 =	38 − 14 =	25 − 11 =
49 − 23 =	27 − 16 =	46 − 32 =



Susa.

21 − 10 =	43 − 10 =	16 − 10 =
28 − 10 =	27 − 10 =	22 − 10 =
34 − 10 =	37 − 10 =	45 − 10 =



Umehluko phakathi kuka-35 no-20 ngu? Dweba isithombe ukhombise impendulo yakho.

35 − 20 = ____



Enza izibalo zamagama usebenzise izithombe. ☐ − ☐ = ☐





Teacher:
Sign:
Date:



Usuku:

Okusindayo nokulula

1 Buka isithombe esilandelayo bese uphendula umbuzo.

Yikuphi okulula kakhulu; yikuphi okusindayo kakhulu?





2 Namathisela kumbe udwebe izithombe zalokhu:

Izinto ezisindayo	Izinto ezilula



Umbala ophuzi ukhombisa izinto ezilula, osasibhakabhaka ngezisindayo.
Bhala kulula kumbe kuyasinda.



Kulula













Dweba kumbe unamathisele izinto ulandela okushiwo yisikali.











Teacher:
Sign:
Date:



Usuku: _____

Amaphethini ezinombolo: Ngazimbili

1 Masibaleni ngakubili.





2 Dweba noma unamathisele izithombe zezinto ezihamba ngazimbili.

3 Sesiyiqalile iphethini. Iqedele.

1	2	3	4	5	6	7	8	9	10
11	12	13	14	15	16	17	18	19	20
21	22	23	24	25	26	27	28	29	30
31	32	33	34	35	36	37	38	39	40
41	42	43	44	45	46	47	48	49	50
51	52	53	54	55	56	57	58	59	60
61	62	63	64	65	66	67	68	69	70
71	72	73	74	75	76	77	78	79	80
81	82	83	84	85	86	87	88	89	90
91	92	93	94	95	96	97	98	99	100



Sebenzisa umugqa wezinombolo ukubhala iphethini.

0 1 2 3 4 5 6 7 8 9 10

2 4 6 8 10

10 11 12 13 14 15 16 17 18 19 20

20 21 22 23 24 25 26 27 28 29 30

0 1 2 3 4 5 6 7 8 9 10

Qedela lokhu okulandelayo:

2, 4, 6, __ , __ , __	13, 15, 17, __ , __ , __	26, 24, 22, __ , __ , __
62, 64, 66, __ , __ , __	55, 57, 59, __ , __ , __	9, 7, 5, __ , __ , __
44, 46, 48, __ , __ , __	10, 8, 6, __ , __ , __	29, 27, 25, __ , __ , __
1, 3, 5, __ , __ , __	98, 96, 94, __ , __ , __	95, 93, 91, __ , __ , __

2 4 6 8 10 12 14 16 18 20

Teacher:
Sign:
Date:

11 12 13 14 15 16 17 18 19 20

Usuku: _____

Phinda kabili

1 Bheka ithebula lokuqala nelesibili. Kwenzekeni?





2 Hlanganisa amachashaza, bese ubhala isibalo sakho ngakunye.

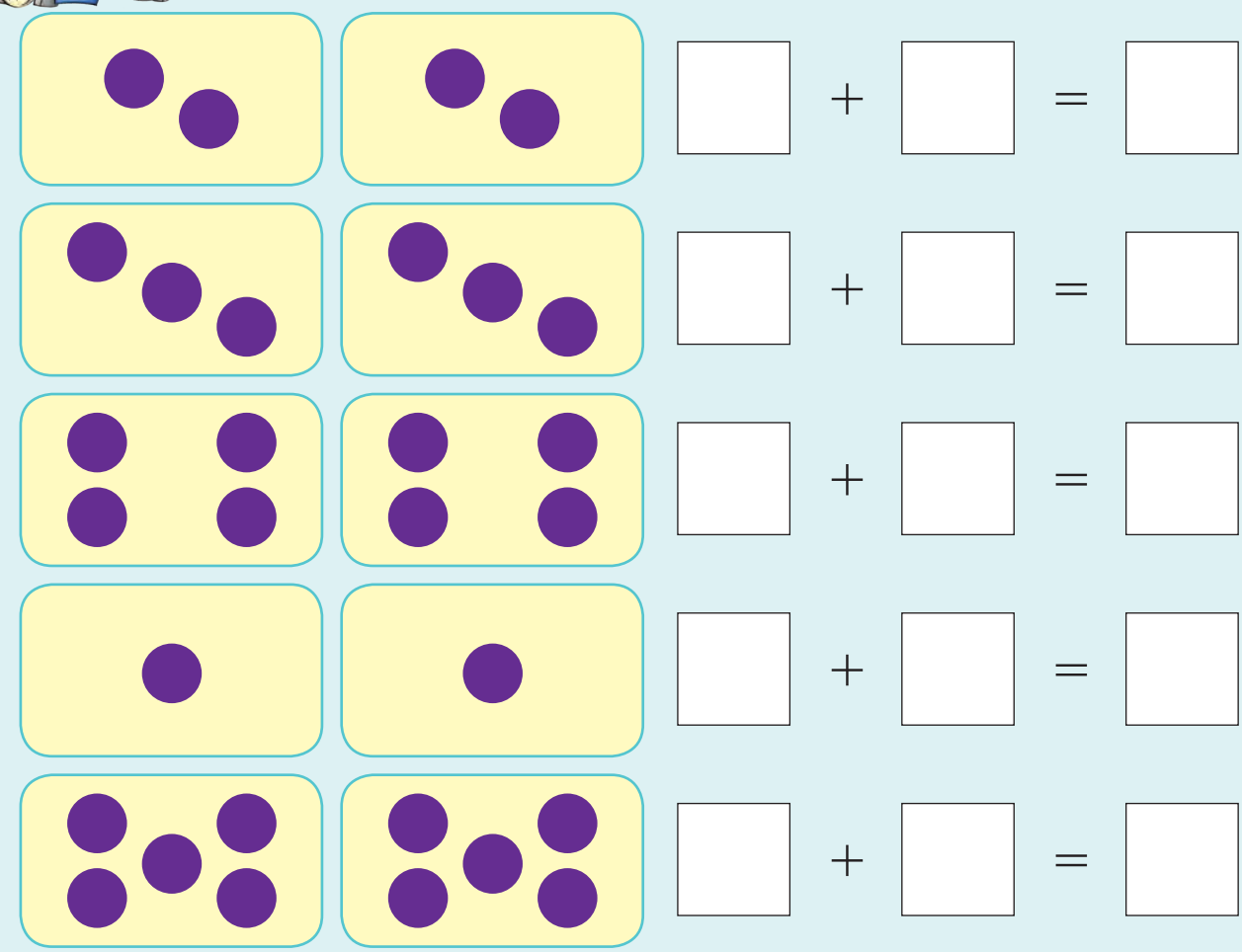



Sebenzisa umugqa wezinombolo ukubhala isibalo.

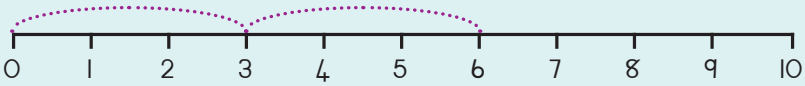

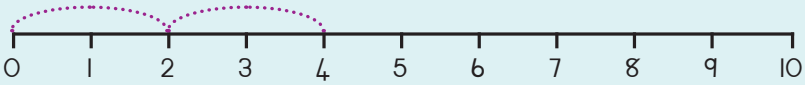

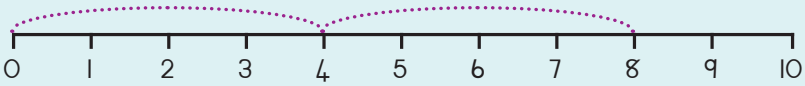

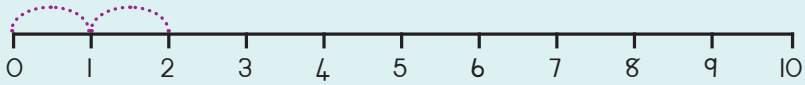

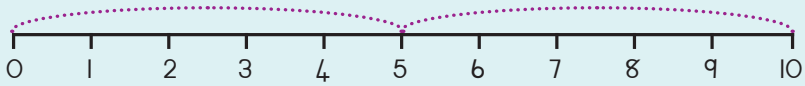

$\square + \square = \square$

$\square + \square = \square$

$\square + \square = \square$

$\square + \square = \square$

$\square + \square = \square$

Phinda kabili lokhu okulandelayo.

Phinda kabili u-1: $1 + 1 = 2$; $2 \times 1 = 2$

Phinda kabili u-2: $\square + \square = \square$; $2 \times \square = \square$

Phinda kabili u-3: $\square + \square = \square$; $2 \times \square = \square$

Phinda kabili u-4: $\square + \square = \square$; $2 \times \square = \square$

Phinda kabili u-5: $\square + \square = \square$; $2 \times \square = \square$

Nginama R5. Umngane unephindwe kabili. Unamalini?

Teacher:
Sign:
Date:

11 12 13 14 15 16 17 18 19 20

Usuku:

Kuphinde kabili futhi

1 Bheka ithebula lokuqala nelesibili. Kwenzekeni?



2 Hlanganisa amachashaza, bese ubhala isibalo ngakunye.

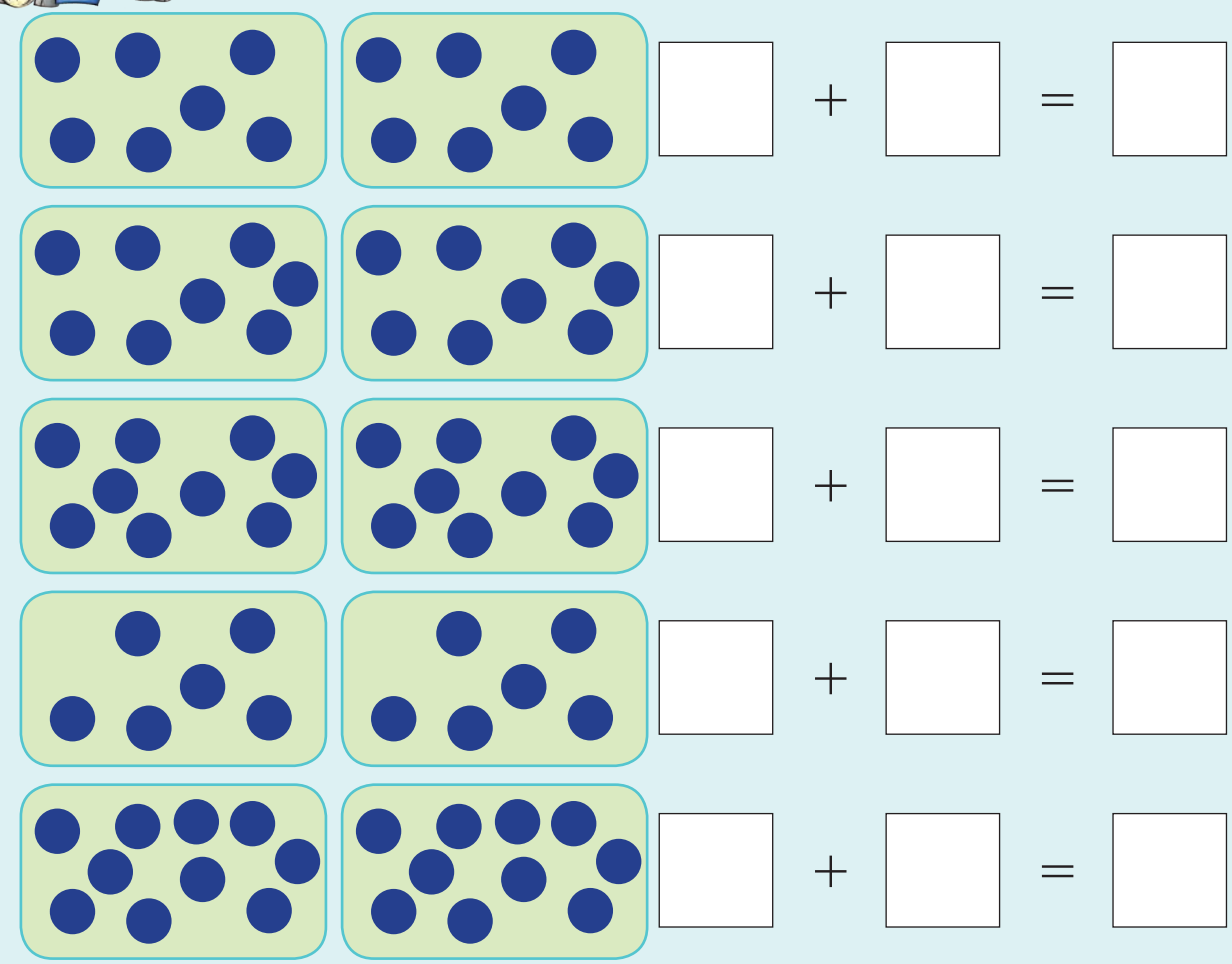





Sebenzisa umugqa wezinombolo ukubhala isibalo.

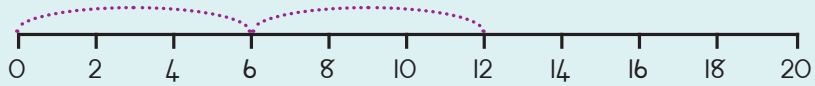

□ + □ = □

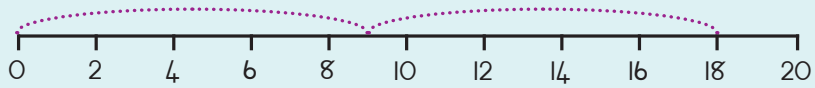

□ + □ = □

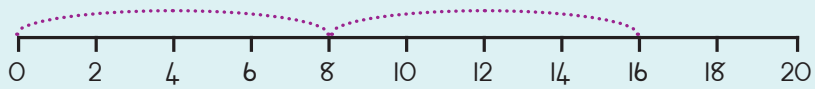

□ + □ = □

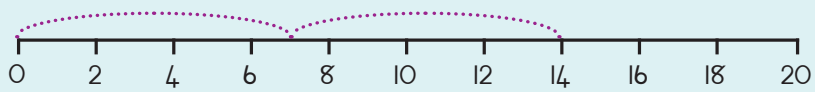

□ + □ = □

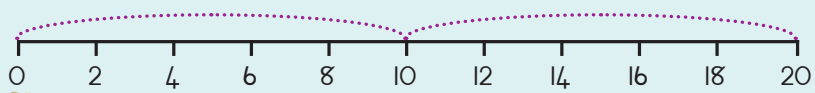

□ + □ = □

Phinda kabili lokhu okulandelayo.

Phinda kabili u-6

□ + □ = □

2 × 6 = 12

Phinda kabili u-7

□ + □ = □

2 × □ = □

Phinda kabili u-8

□ + □ = □

2 × □ = □

Phinda kabili u-9

□ + □ = □

2 × □ = □

Phinda kabili u-10

□ + □ = □

2 × □ = □

Umngane unezimabuli eziyisi-9. Ngiziphinda kabili mina. Zingaki ezami?

Teacher:

Sign:

Date:

Usuku: _____

Kuphinde kabili

Phinda kabili u-8

1 2 3 4 5 6 7 8 1 2 3 4 5 6 7 8



1 2 3 4 5 6 7 8 9 10 11 12 13 14 15 16

Phinda kabili u-9

1 2 3 4 5 6 7 8 9 1 2 3 4 5 6 7 8 9



1 2 3 4 5 6 7 8 9 10 11 12 13 14 15 16 17 18



Sebenzisa ubuhlalu ukuphinda kabili izinombolo. Sikuqalelile esokuqala.

Phinda kabili u-5



5 + 5 = ☐

Phinda kabili u-6



☐ + ☐ = ☐

Phinda kabili u-7



☐ + ☐ = ☐

Phinda kabili u-8



☐ + ☐ = ☐

Phinda kabili u-9



☐ + ☐ = ☐



Phinda kabili izinombolo. Faka umbala ebhokisini lamashumi ukuveza impendulo yakho.

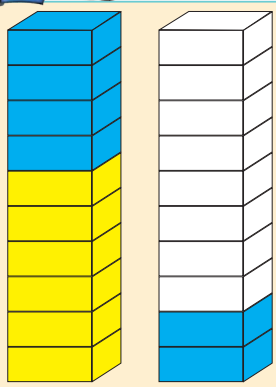

Phinda kabili u-6

6 + 6 = ☐

2 × 6 = ☐

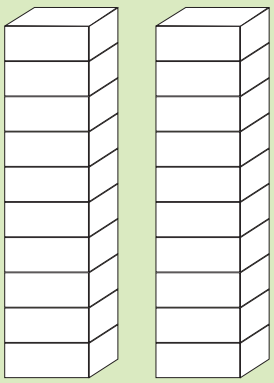

Phinda kabili u-8

☐ + ☐ = ☐

2 × ☐ = ☐

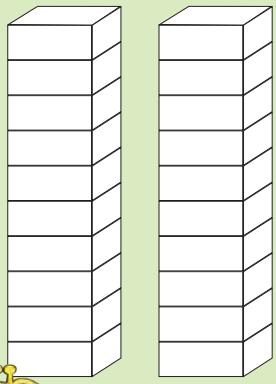

Phinda kabili u-7

☐ + ☐ = ☐

2 × ☐ = ☐

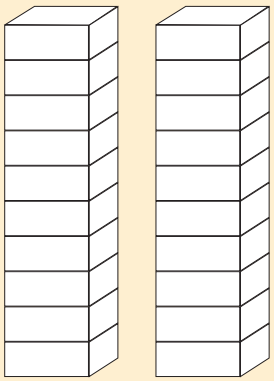

Phinda kabili u-9

☐ + ☐ = ☐

2 × ☐ = ☐



Phinda kabili lokhu okulandelayo.

Phinda kabili u-7	☐ + ☐ = ☐	2 × ☐ = ☐
Phinda kabili u-9	☐ + ☐ = ☐	2 × ☐ = ☐
Phinda kabili u-6	☐ + ☐ = ☐	2 × ☐ = ☐
Phinda kabili u-8	☐ + ☐ = ☐	2 × ☐ = ☐
Phinda kabili u-10	☐ + ☐ = ☐	2 × ☐ = ☐



Nginamaphuzu ayisi-8. Umngane uwaphinde kabili. Unamangaki?

Teacher:

Sign:

Date:



Usuku: _____

Okunye ngokuphinda kabili

Phinda kabili u-12





Sebenzisa ubuhlalu ukuphinda kabili izinombolo. Sikuqalelile ezokuqala.

Phinda kabili u-13

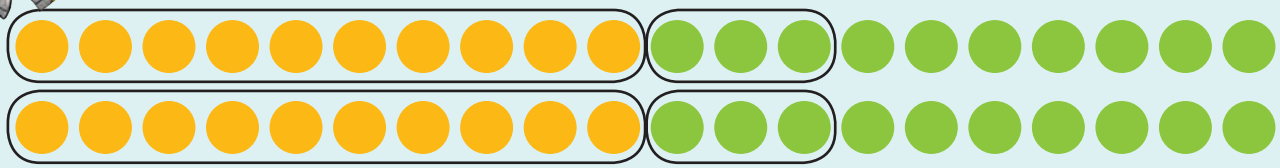

Phinda kabili u-15 ☐ + ☐ = ☐

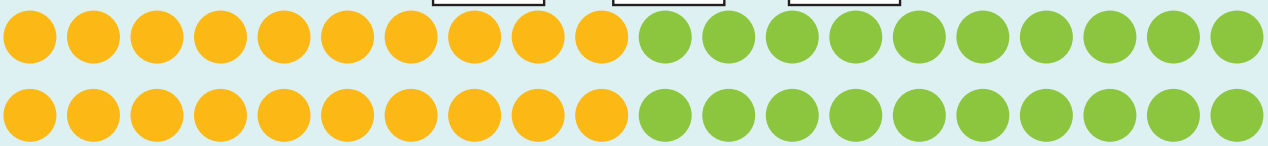

Phinda kabili u-14 ☐ + ☐ = ☐



Phinda kabili u-11 ☐ + ☐ = ☐



Phinda kabili u-16 ☐ + ☐ = ☐



☐ + ☐ = ☐







Phinda kabili izinombolo. Faka umbala ebhokisini lamashumi ukuveza impendulo yakho.

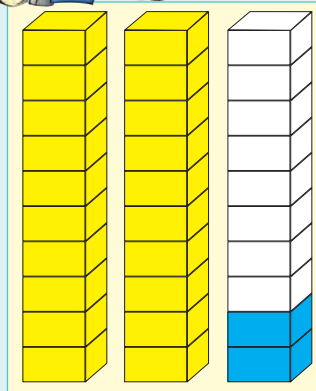

Phinda kabili u-11

II + II = ☐

2 × II = ☐



Phinda kabili u-13

☐ + ☐ = ☐

2 × ☐ = ☐

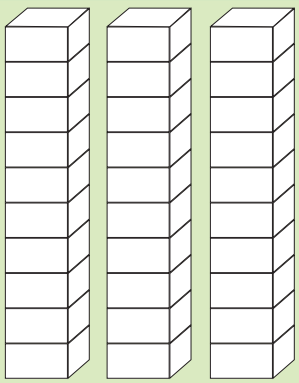

Phinda kabili u-14

☐ + ☐ = ☐

2 × ☐ = ☐



Phinda kabili u-15

☐ + ☐ = ☐

2 × ☐ = ☐



Phinda kabili lokhu okulandelayo.

Phinda kabili u-11	☐ + ☐ = ☐	2 × ☐ = ☐
Phinda kabili u-13	☐ + ☐ = ☐	2 × ☐ = ☐
Phinda kabili u-16	☐ + ☐ = ☐	2 × ☐ = ☐
Phinda kabili u-17	☐ + ☐ = ☐	2 × ☐ = ☐
Phinda kabili u-18	☐ + ☐ = ☐	☐ × ☐ = ☐



Ngidle i-14 lamakhekhe. Umngane udle aphindwe kabili. Udle amangaki?

Teacher:

Sign:

Date:



11 12 13 14 15 16 17 18 19 20

Usuku:

Iziqukathi nokuqukatha

1 Khuluma ngeziqukathi ezisemadeskini.



2 Yisho ukuthi isiqukathi sigcwele kumbe kasinalutho yini.

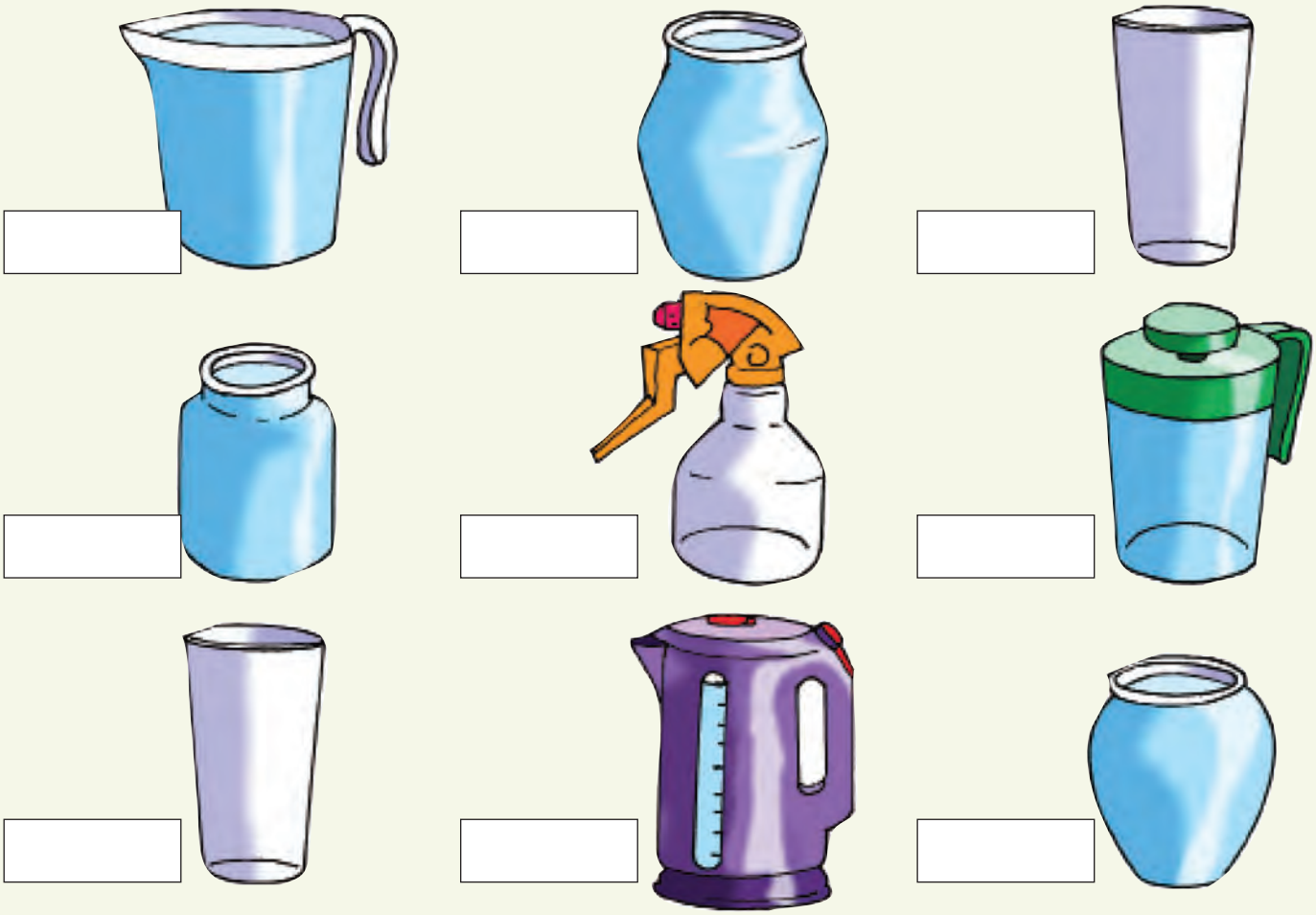



Faka umbala noma yiluphi uketshezi kulezi ziqukathi.

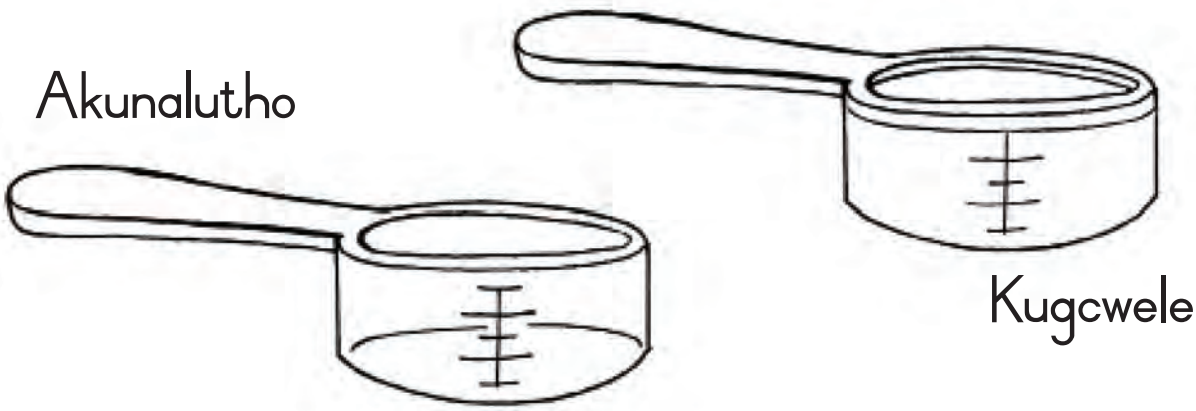



Dweba ezakho iziqukathi ufake umbala kulokho ezikuqukethe.

Akunalutho	Kugcwele
Akunalutho	Kugcwele

Teacher:
Sign:
Date:

Usuku:

Ukuphindaphinda: x 3

Mangaki amaswidi asetafuleni ngalinye?



Qedela lokhu okulandelayo.

Amaqembu amabili okungakuthathu	3 + 3 =	3 × 2 = ☐
Amaqembu amathathu okungakuthathu	3 + 3 + 3 =	3 × 3 = ☐
Amaqembu amane okungakuthathu	3 + 3 + 3 + 3 =	3 × 4 = ☐
Amaqembu ayisithupha okungakuthathu	3 + 3 + 3 + 3 + 3 + 3 =	3 × 6 = ☐
Amaqembu ayisikhombisa okungakuthathu	3 + 3 + 3 + 3 + 3 + 3 + 3 =	3 × 7 = ☐

Dweba lokhu okulandelayo.

Amaqembu amathathu okungakuthathu	Amaqembu amane okungakuthathu	Amaqembu amahlanu okungakuthathu



Dweba lokhu okulandelayo.

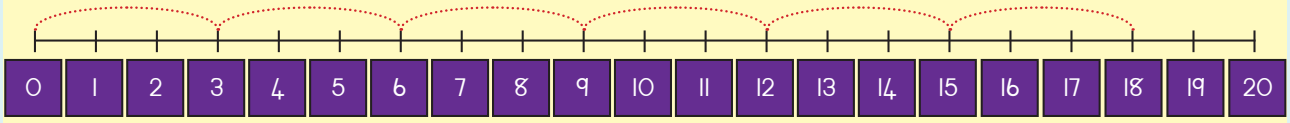

3, 6, 9, 12, ___ , ___

3 + 3 + 3 + 3 + 3 + 3= ☐

6 × 3 = ☐

Umdwebo

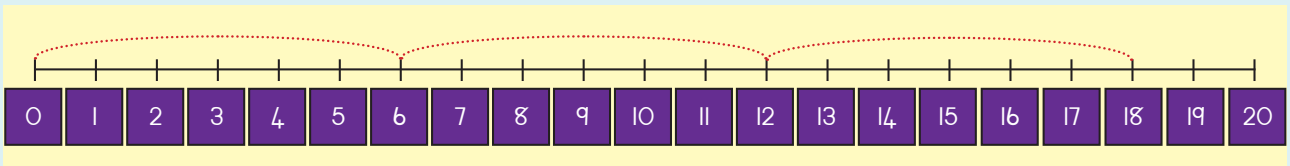

6, ___ , ___

6 + ☐ + ☐ = ☐

3 × ☐ = ☐

Umdwebo

Ibhodwe lokupheka linemilenze emithathu. Amabhodwe ayi-7 anemilenze emingaki? ☐



3 6 9 12 15 18

21 24 27 30 33

Teacher:

Sign:

Date:

Usuku: _____

Amaphethini ezinombolo: Ngakuthathu

Masibaleni ngakutthathu.





Dweba noma unamathisele izinto ezihamba ngazintathu.

Sesiyiqalile iphethini. Iqedele.

1	2	3	4	5	6	7	8	9	10
11	12	13	14	15	16	17	18	19	20
21	22	23	24	25	26	27	28	29	30
31	32	33	34	35	36	37	38	39	40
41	42	43	44	45	46	47	48	49	50
51	52	53	54	55	56	57	58	59	60
61	62	63	64	65	66	67	68	69	70
71	72	73	74	75	76	77	78	79	80
81	82	83	84	85	86	87	88	89	90
91	92	93	94	95	96	97	98	99	100



Sebenzisa umugqa wezinombolo ukubhala iphethini.

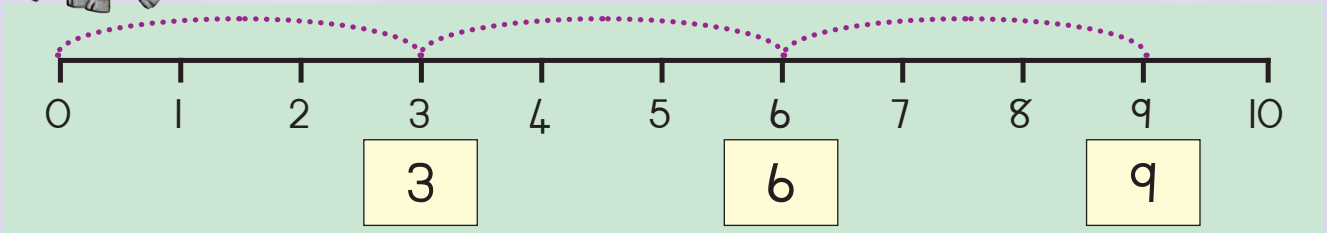

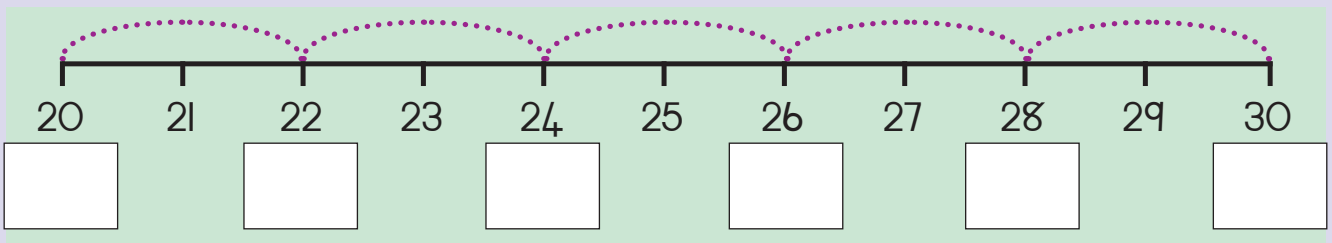

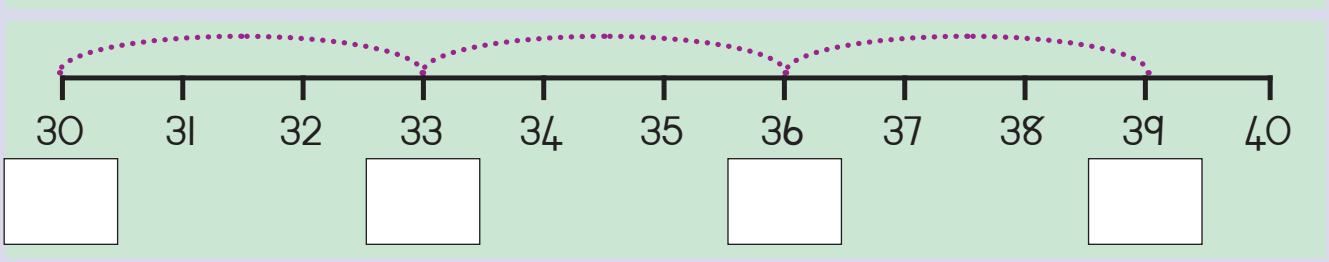

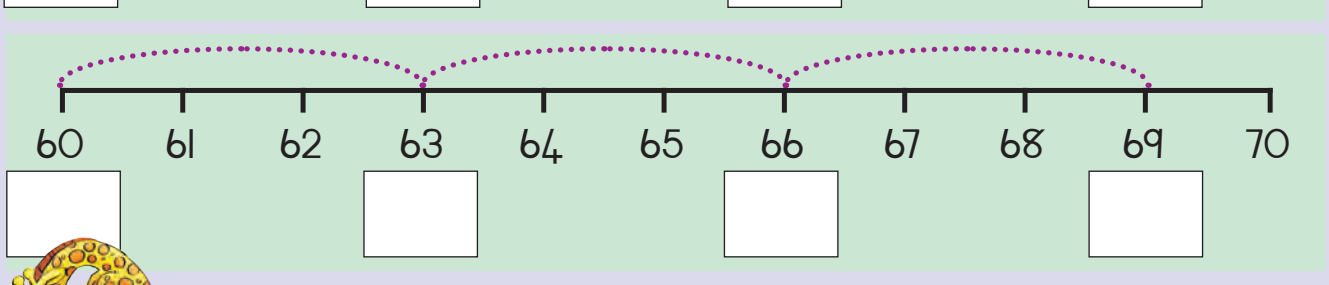



Qedela lokhu okulandelayo.

3, 6, 9, __ , __ , __	1, 4, 7, __ , __ , __	99, 96, 93, __ , __ , __
36, 39, 42, __ , __ , __	22, 25, 28, __ , __ , __	66, 63, 60, __ , __ , __
12, 15, 18, __ , __ , __	15, 12, 9, __ , __ , __	40, 37, 34, __ , __ , __



Kunemathrayisikili ayi-10 enkulisa. Mangaki amasondo awo uma uwabala wonke?

Teacher:
Sign:
Date:



Usuku: _____

Ukuphindaphinda: x 4

Mangaki amaswidi asetafuleni ngalinye?



Qedela lokhu okulandelayo.

Amaqembu amathathu okungakune	4 + 4 + 4 =	3 × 4 = ☐
Amaqembu amabili okungakune	4 + 4 =	2 × 4 = ☐
Amaqembu amane okungakune	4 + 4 + 4 + 4 =	4 × 4 = ☐
Amaqembu ayisithupha okungakune	4 + 4 + 4 + 4 + 4 + 4 =	6 × 4 = ☐
Amaqembu ayisikhombisa okungakune	4 + 4 + 4 + 4 + 4 + 4 + 4 =	7 × 4 = ☐

Dweba lokhu okulandelayo.

Amaqemu amathathu okungakune	Amaqembu amane okungakune	Amaqembu amahlanu okungakune



Dweba lokhu okulandelayo.

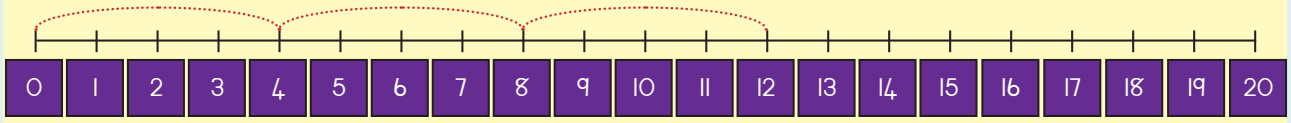

4, 8, ___

4 + 4 + 4 = ☐

4 × 3 = ☐

Umdwebo



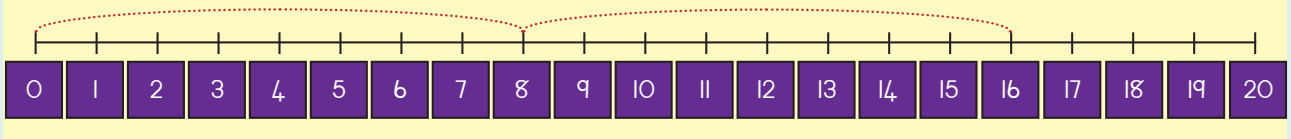

8, ___

8 + ☐ = ☐

8 × ☐ = ☐

Umdwebo



Ihhashi linemilenze emine.
Amahhashi amathathu anemilenze emingaki? ☐



4 8 12 16 20 24

28 32 36 40

Teacher:

Sign:

Date:





Usuku: _____

Amaphethini ezinombolo: Ngakune

1 Masibaleni ngakune.





2 Dweba noma unamathisele izinto ezihamba ngazine.

3 Siyiqalile iphethini. Iqedele.

1	2	3	4	5	6	7	8	9	10
11	12	13	14	15	16	17	18	19	20
21	22	23	24	25	26	27	28	29	30
31	32	33	34	35	36	37	38	39	40
41	42	43	44	45	46	47	48	49	50
51	52	53	54	55	56	57	58	59	60
61	62	63	64	65	66	67	68	69	70
71	72	73	74	75	76	77	78	79	80
81	82	83	84	85	86	87	88	89	90
91	92	93	94	95	96	97	98	99	100





Sebenzisa umugqa wezinombolo ukubhala iphethini.

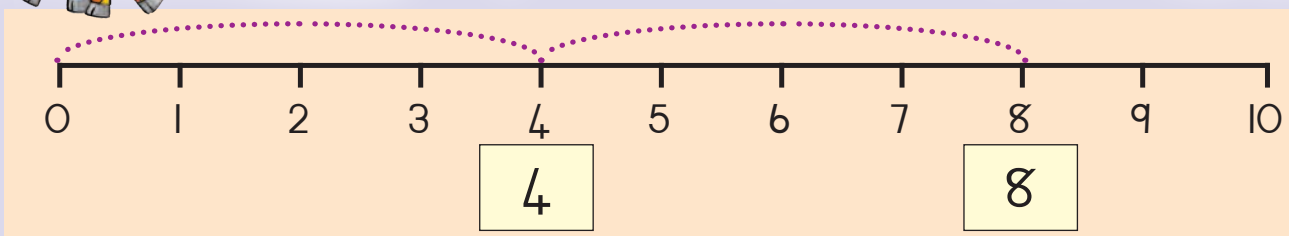

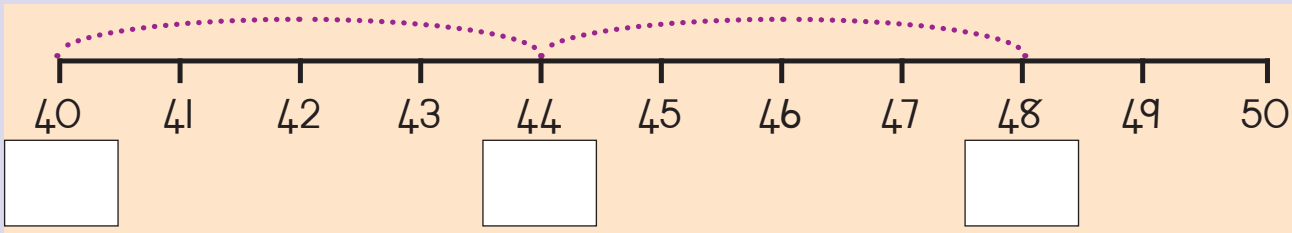

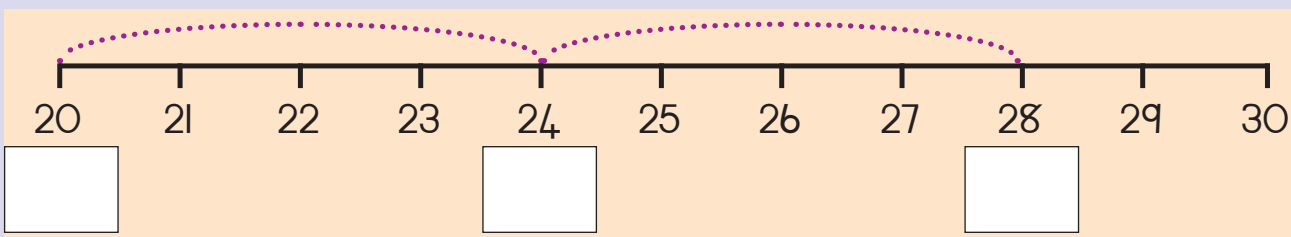

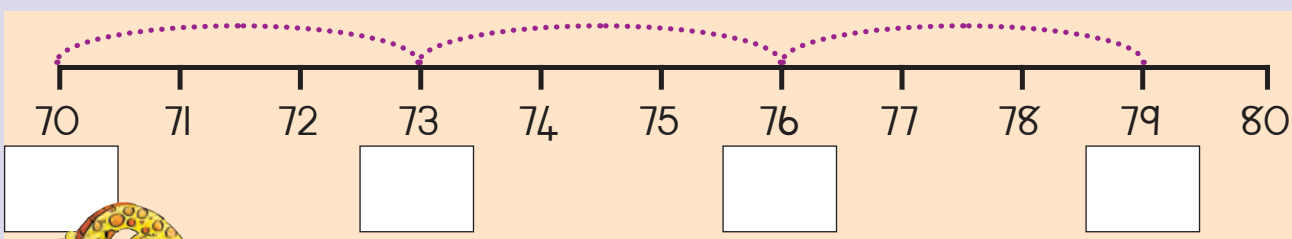



Qedela lokhu okulandelayo.

4, 8, 12, __ , __ , __	1, 5, 9, __ , __ , __	48, 44, 40, __ , __ , __
28, 32, 36, __ , __ , __	42, 46, 50, __ , __ , __	60, 56, 52, __ , __ , __
12, 16, 20, __ , __ , __	20, 16, 12, __ , __ , __	70, 66, 62, __ , __ , __



Kunamakhekhe ama-4 ephaketheni. Ngithengise ayisi-9. Abemangaki ngingakathengisi?

Teacher:
Sign:
Date:



Usuku:

Izindaba zokuphindaphinda

Yenza eyakho indaba usebenzise amagama afana namehlo, imilenze, izandla, izinyawo, izilwane, kanye nabantu. Faka inombolo kukho ngakunye.



Ikati linamehlo amabili. Anamehlo amangaki amakati amane?



Faka umbala emehlweni amakati.

Akhombise ngezinto zokubala.

Kukhombise emgqeni wezinombolo.

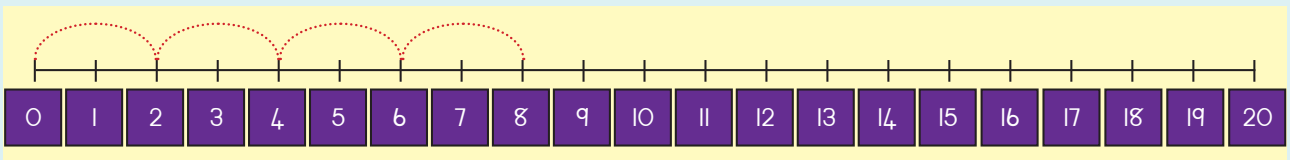

□ + □ + □ + □ = □

□ × □ = □



Ibhayisikili elinamasondo amathathu linamasondo amathathu. Amabhayisikili anamasondo amathathu anamasondo amangaki uma emahlanu?



Faka umbala emasondweni ebhayisikili.

Akhombise ngezinto zokubala.

Kukhombise emgqeni wezinombolo.

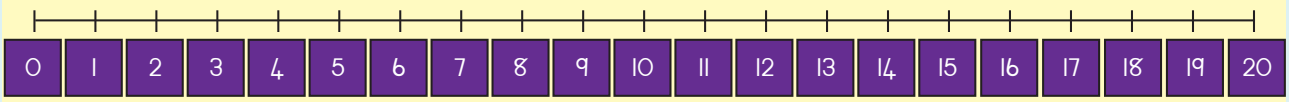

\+ = × =

Inja inemilenze emine. Mingaki imilenze uma izinja zizine.



Faka umbala emilenzeni yenja.

Akhombise ngezinto zokubala.

Kukhombise emgqeni wezinombolo.

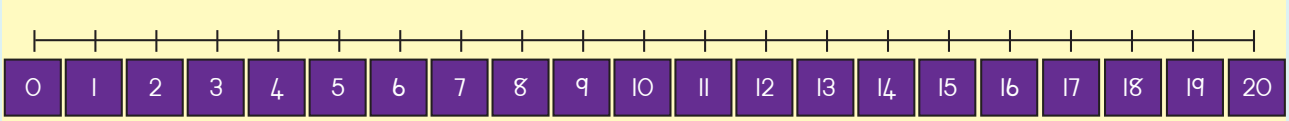

\+ = × =

Teacher:
Sign:
Date:

Usuku:

Amahora

Khuluma ngewashi.



Uluthi olufushane lusikhombisa amahora.

Lapha lithi yihora lesi-7.

Uluthi ewashini luhamba luzungeleze sonke isikhathi. Lizungeleze lizungeleze. Uluthi ewashini luhamba luzungeleze, ukusitshela isikhathi.

2 Uluthi olufushane lusikhombisani?



ihora



amahora



amahora



amahora



amahora



amahora



amahora



amahora



amahora



amahora



amahora



amahora

Dweba uluthi olufushane.

4 amahora



1 ihora



11 amahora



7 amahora



9 amahora



10 amahora



2 amahora



5 amahora



3 amahora



6 amahora



8 amahora



12 amahora



Yini eyenzeka ithathe ihora? Faka umbala empendulweni efanele.



Ukwenza umsebenzi wesikole



Ukulala



Ukuxubha amazinyo

Teacher:

Sign:

Date:

Usuku: _____

Amaphethini ezinombolo: Awokuhlanu

1 Masibaleni ngakuhlanu.





2 Dweba noma unamathisele izinto ezihamba ngazinhlanu.

3 Siyiqalile iphethini. Iqedele.

1	2	3	4	5	6	7	8	9	10
11	12	13	14	15	16	17	18	19	20
21	22	23	24	25	26	27	28	29	30
31	32	33	34	35	36	37	38	39	40
41	42	43	44	45	46	47	48	49	50
51	52	53	54	55	56	57	58	59	60
61	62	63	64	65	66	67	68	69	70
71	72	73	74	75	76	77	78	79	80
81	82	83	84	85	86	87	88	89	90
91	92	93	94	95	96	97	98	99	100



Sebenzisa umugqa wezinombolo ukubhala iphethini.

0 1 2 3 4 5 6 7 8 9 10

0 5 10

40 41 42 43 44 45 46 47 48 49 50

21 22 23 24 25 26 27 28 29 30 31

70 71 72 73 74 75 76 77 78 79 80

Qedela lokhu okulandelayo.

5, 10, 15, __ , __ , __	1, 6, 11, __ , __ , __	50, 45, 40, __ , __ , __
20, 25, 30, __ , __ , __	23, 28, 33, __ , __ , __	60, 55, 50, __ , __ , __
30, 35, 40, __ , __ , __	25, 20, 15, __ , __ , __	54, 49, 44, __ , __ , __

5 10 15 20 25 30 35 40 45 50

Teacher:
Sign:
Date:

11 12 13 14 15 16 17 18 19 20

Usuku:

Imizuzu

1 Siyibiza ngani imigqa emifushane eyenziwe ngamachashazi ewashini?





Yizini izinto ongazenza uziqede esikhathini esingangomzuzu.

2 Gcwalisa imizuzu.

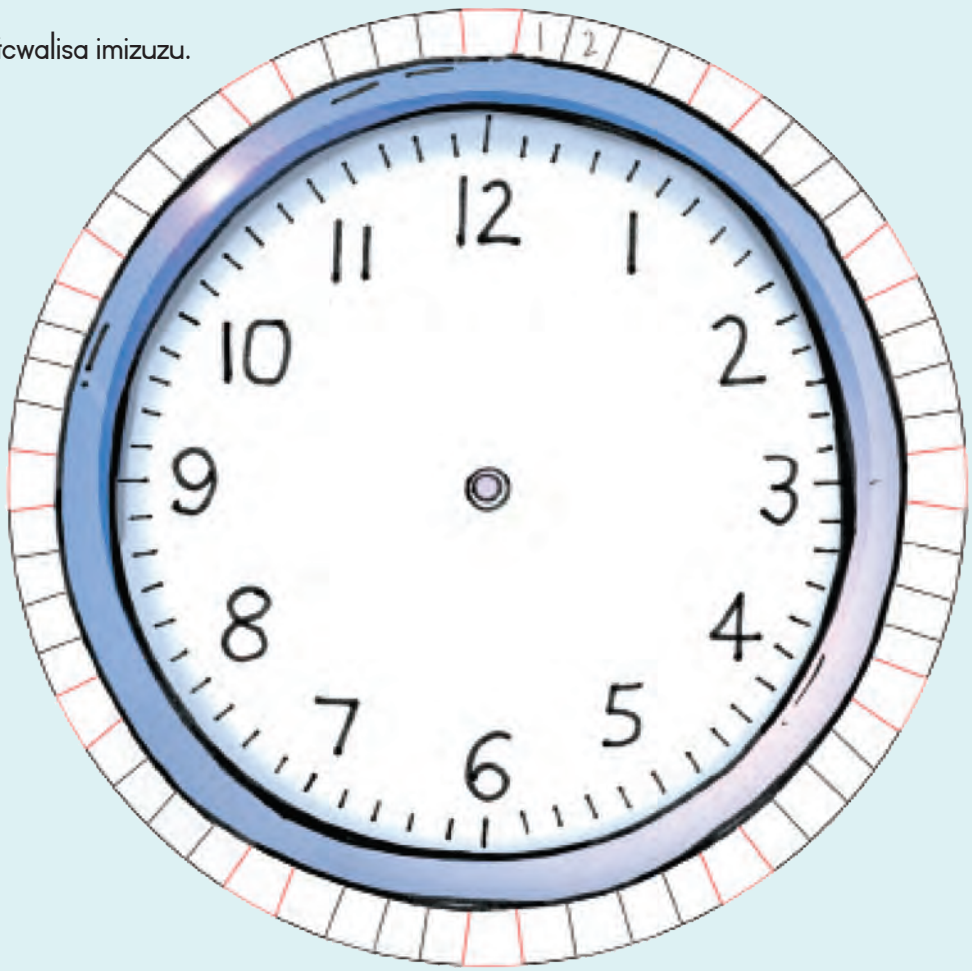

3 Bhala lapha izinombolo ezisezikweleni ezibomvu.



Enza isithombe sezinto ongazenza esikhathini ...

Umzuzu owodwa	Imizuzu emi-5
Imizuzu engama-30	Imizuzu engama-60

Teacher:
Sign:
Date:

57b

Usuku:

Imizuzu eyengeziwe

1 Khuluma ngewashi.



Uthi olude lusikhombisa imizuzu.

Lapha lisikhombisa imizuzu elishumi.

Uluthi ewashini luhamba luzungeleze sonke isikhathi. Lizungeleze lizungeleze. Uluthi ewashini luhamba luzungeleze, ukusitshela isikhathi.

2 Lusikhombisani uthi olude?



imizuzu



imizuzu



imizuzu



imizuzu



imizuzu



imizuzu

1 2 3 4 5 6 7 8 9 10

Dweba uthi olude.

35 imizuzu



60 imizuzu



10 imizuzu



45 imizuzu



12 imizuzu



Yini engathatha umzuzu owodwa? Faka umbala empendulweni eqinisile.



Ukudlala



Ukudlala ingqathu



Ukudla

Teacher:

Sign:

Date:

11 12 13 14 15 16 17 18 19 20

Usuku:

Ukubeka ngamaqoqo kanye nokwabelana

1 Mangaki amabhloki esiyingini ngasinye? Yabela izingane.



2 Mangaki amabhokisi esiyingini ngasinye? Bhala inani esiyingini esiluhlaza.

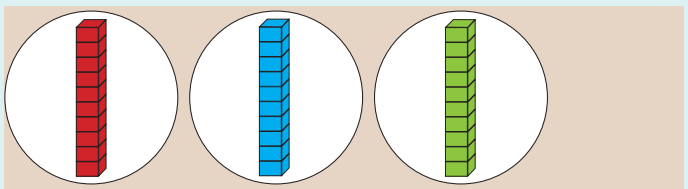

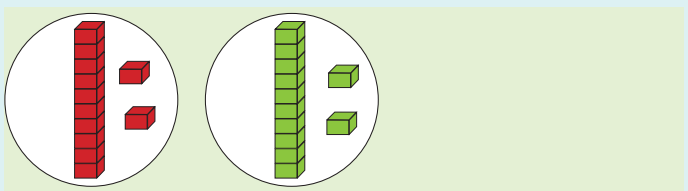

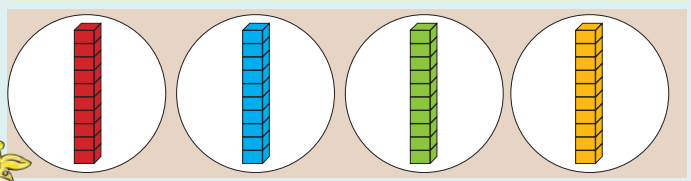

□ × □ = □

□ × □ = □

□ × □ = □

3 Yaba amabhokisi alingane eziyingini.

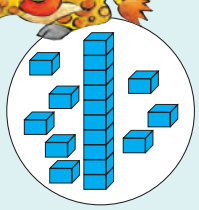

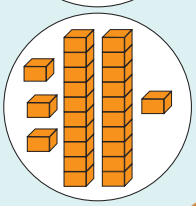

□ ÷ □ = □

□ ÷ □ = □



Dweba lokhu okulandelayo. Bhala isibalo sakho ngakunye.

Amaqoqo amathathu okuhamba ngakubili

+ Hlanganisa isibalo:

× Phindaphinda isibalo:

Amaqoqo amabili okuhamba ngama-25

+ Hlanganisa isibalo:

× Phindaphinda isibalo:

Yabela abantu abane izinto zokubala eziyi-12

− Isibalo sokususa:

÷ Isibalo sokuhlukanisa:

Yabela abantu abathathu izinto zokubala ezingama-36.

− Isibalo sokususa:

÷ Isibalo sokuhlukanisa:

Bala:

Amaqoqo amabili ezinto ezihamba ngasikhombisa _____.

Amaqoqo amathathu ezinto ezihamba ngasishiyagalombili _____.

Amaqoqo amane ezinto ezihamba ngazinhlanu _____.

Amaqoqo amabili ezinto ezihamba nga-15 _____.

Yaba okuyi-18 kabili _____. Yaba okungama-24 kathathu _____.

Yaba okungama-24 kathathu _____.

Yaba okungama-50 kayishumi _____.

Bekunamaqembu ayisi-6 abantu abahamba ngaba-5.
Bebebangaki bebonke abantu emcimbini wami?

Teacher:
Sign:
Date:

Usuku:

Ukubeka ngamaqoqo kanye nokwabelana

1 Mangaki amabhokisi esiyingini ngasinye? Yabela izingane



2 Zingaki izinto zokubala esiyingini ngasinye? Bhala inani esiyingini esiluhlaza.

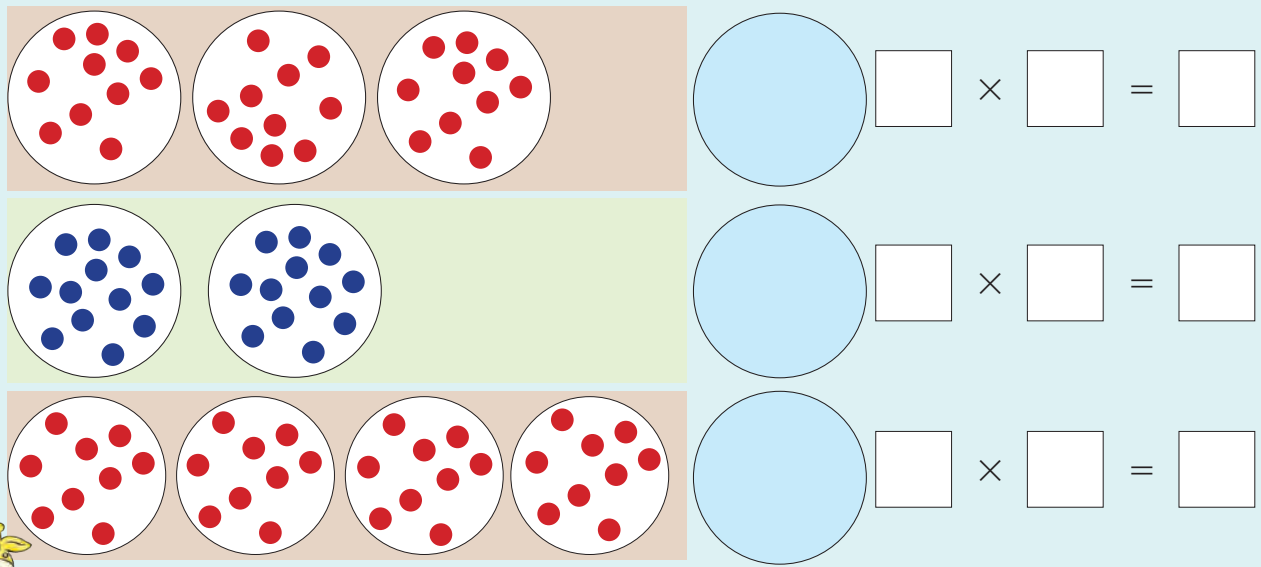

3 Hlukanisela izingane izinto zokubala.

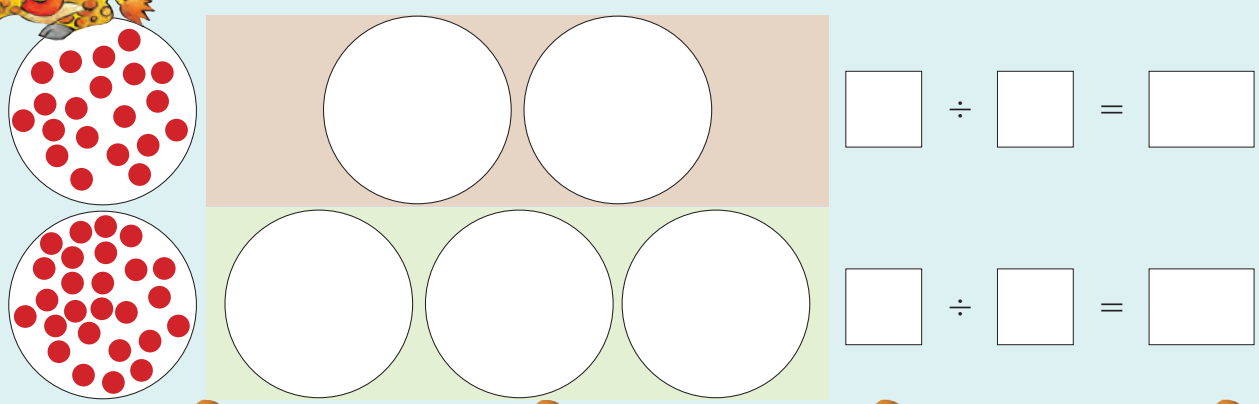



Dweba lokhu okulandelayo. Bhala isibalo sakho ngakunye

Amaqoqo amathathu okuhamba ngaku-12

+ Isibalo sokuhlanganisa:

× Isibalo sokuphindaphinda:

Amaqoqo amahlanu okuhamba ngamashumi.

+ Isibalo sokuhlanganisa:

× Isibalo sokuphindaphinda:

Yaba izinto zokubala kubantu abane.

− Isibalo sokususa:

÷ Isibalo sokuhlukanisa:

Yaba izinto zokubala kubantu abahlanu.

− Isibalo sokususa:

÷ Isibalo sokuhlukanisa:



Bala:

Amaqoqo amabili okuhamba nga-11 _____.

Amaqoqo amathathu okuhamba ngamashumi _____.

Amaqoqo amane okuhamba ngakune _____.

Amaqoqo ahamba ngama-25 _____.

Yaba ama-20 ngakubili _____.

Yaba ama-27 ngakuthathu _____.

Yaba ama-50 ngakuhlanu _____.

Yaba ama-28 ngakubili _____.



Phinda kabili

Teacher:

Sign:

Date:



Usuku: _____

Ukubeka ngamaqoqo kanye nokwabelana

1 Zingaki izinto zokubala ezisesiyingini ngasinye? Yabela izingane ezimbili.



2 Zingaki izinto zokubala ezisesiyingini ngasinye?

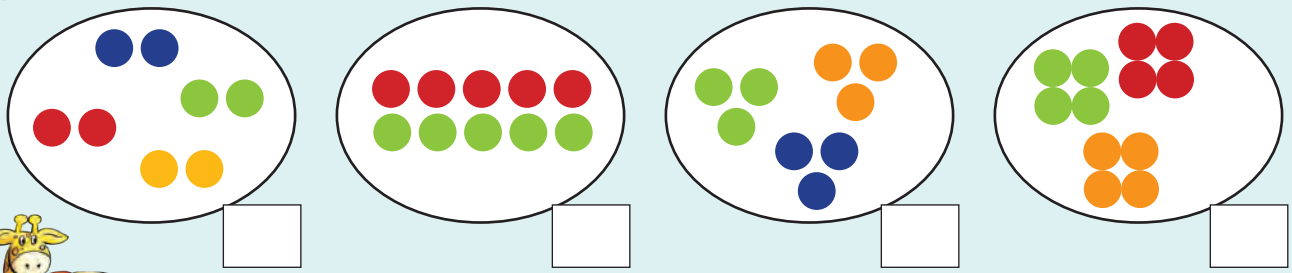

3 Thola ekupheleni kwale ncwadi imimo ebhalwe "Okusikwa Kukho 4" usike umumo uwunamathisele ebhokisini elifanele.

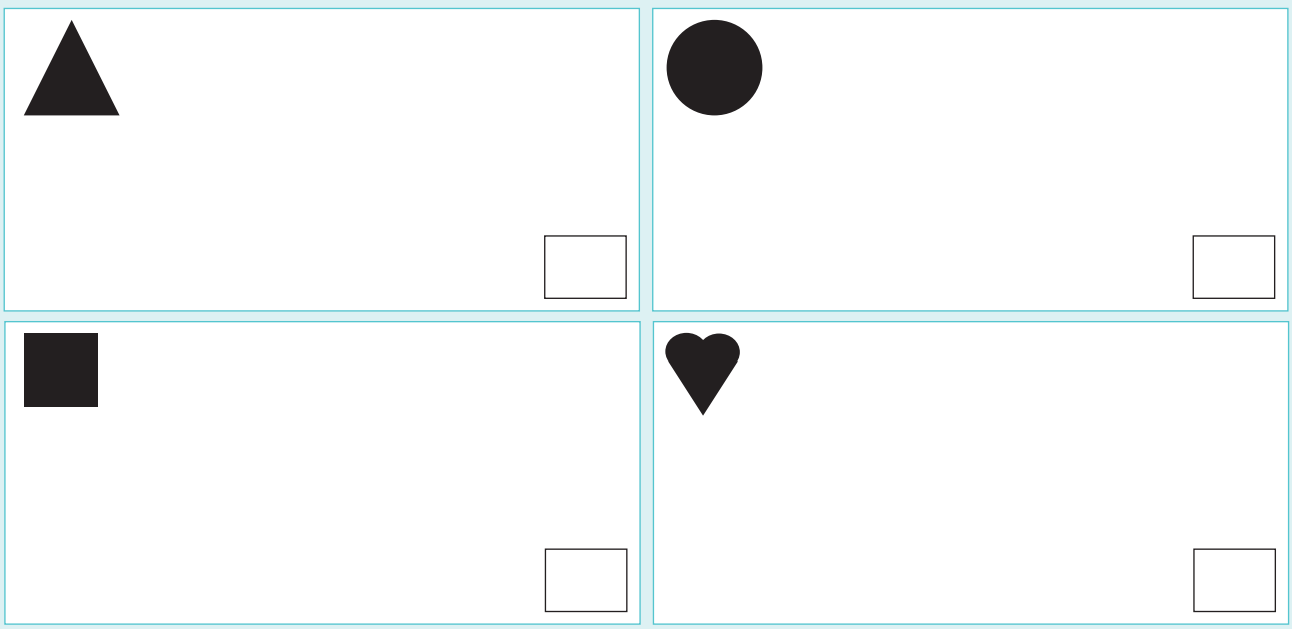



Yabela izingane izimo. Sebenzisa imimo elapho kuthiwe khona "Okusikwa Kukho 4".

onxantathu





izikwele









Yabela izingane izithelo. Kudwebe.





onamawolintshi





onama-apula









UJohan noBelinda babelana amaswidi ayi-12 ngokulingana.
Banamaswidi amangaki ngamunye?

Teacher:
Sign:
Date:



Usuku:

Ukubeka ngamaqoqo kanye nokwabelana

1 Bungaki ubuhlalu obusesiyingini ngasinye. Yabela izingane.



2 Bungaki ubuhlalu esiyingini ngasinye?

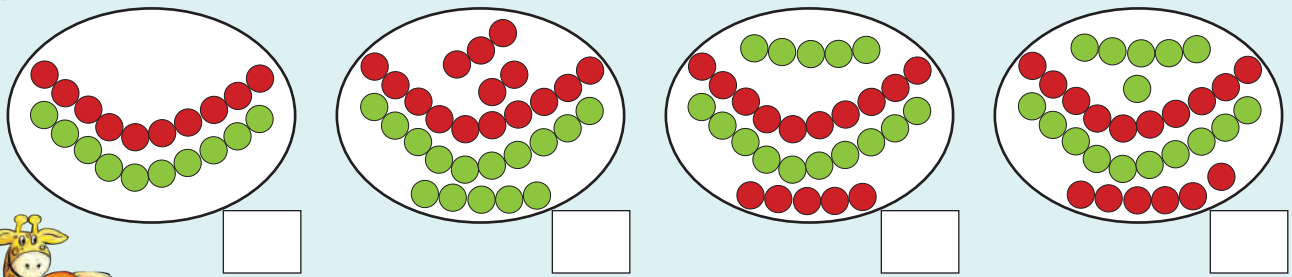

3 Sika ubuhlalu obulapho kuthiwa khona "Okusikwa Kukho 4" ubunamathisele lapha.

Ubuhlalu obubomvu	Ubuhlalu obuluhlaza
Ubuhlalu obuphuzi	Ubuhlalu obuluhlaza satshani



Dweba ubuhlalu obulinganayo bengane ngayinye.






Yabela izingane ubuhlalu. Kudwebe.

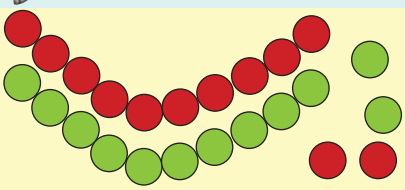
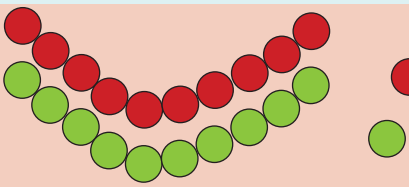







OBusi noZaheda babelana ngamapensela anombala ngokulingana.
Mangaki amapensela atholwa ngumuntu ngamunye?

Teacher:
Sign:
Date:

Usuku:

Uhhafu: 1–20

Kwenzekeni ema-apuleni?





Yaba izithelo ezikubhasikidi ongasesandleni sobunxele ngasesandleni sokudla. Kudwebe.







Dweba umugqa ukukhombisa uhhafu.

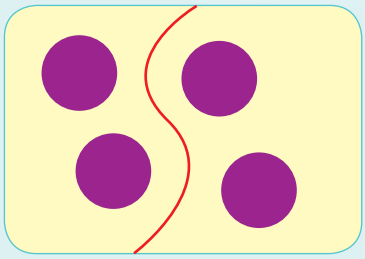

Uhhafu wokune

2



Uhhafu wokuyisithupha



Uhhafu wokuyi-sishiyagalombili



Uhhafu wokubili

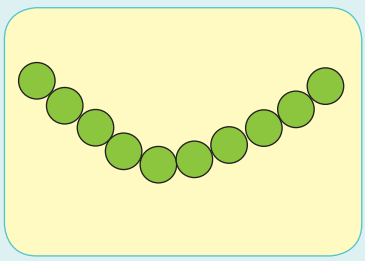

Uhhafu wokuyishumi

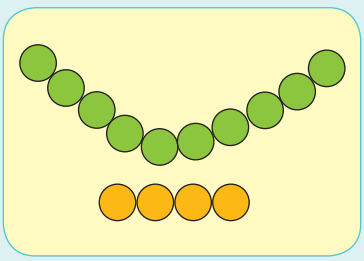

Uhhafu wokuyishumi nane

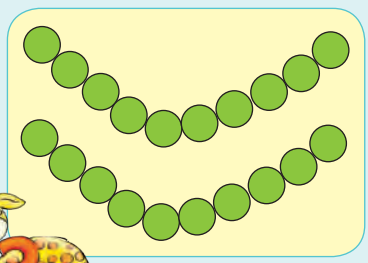

Uhhafu wamashumi amabili

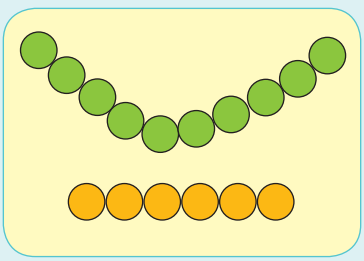

Uhhafu weshumi nesithupha



Yimuphi uhhafu wepuleti lokudla ngalinye?



Teacher:

Sign:

Date:



Usuku:

Ukwabelana 20–50



Kwenzekeni ebuhlalwini?







Yaba ubuhlalu obusebhasikidini ongasesandleni sokunxele kubhasikidi ongasesandleni sokudla. Kudwebe.

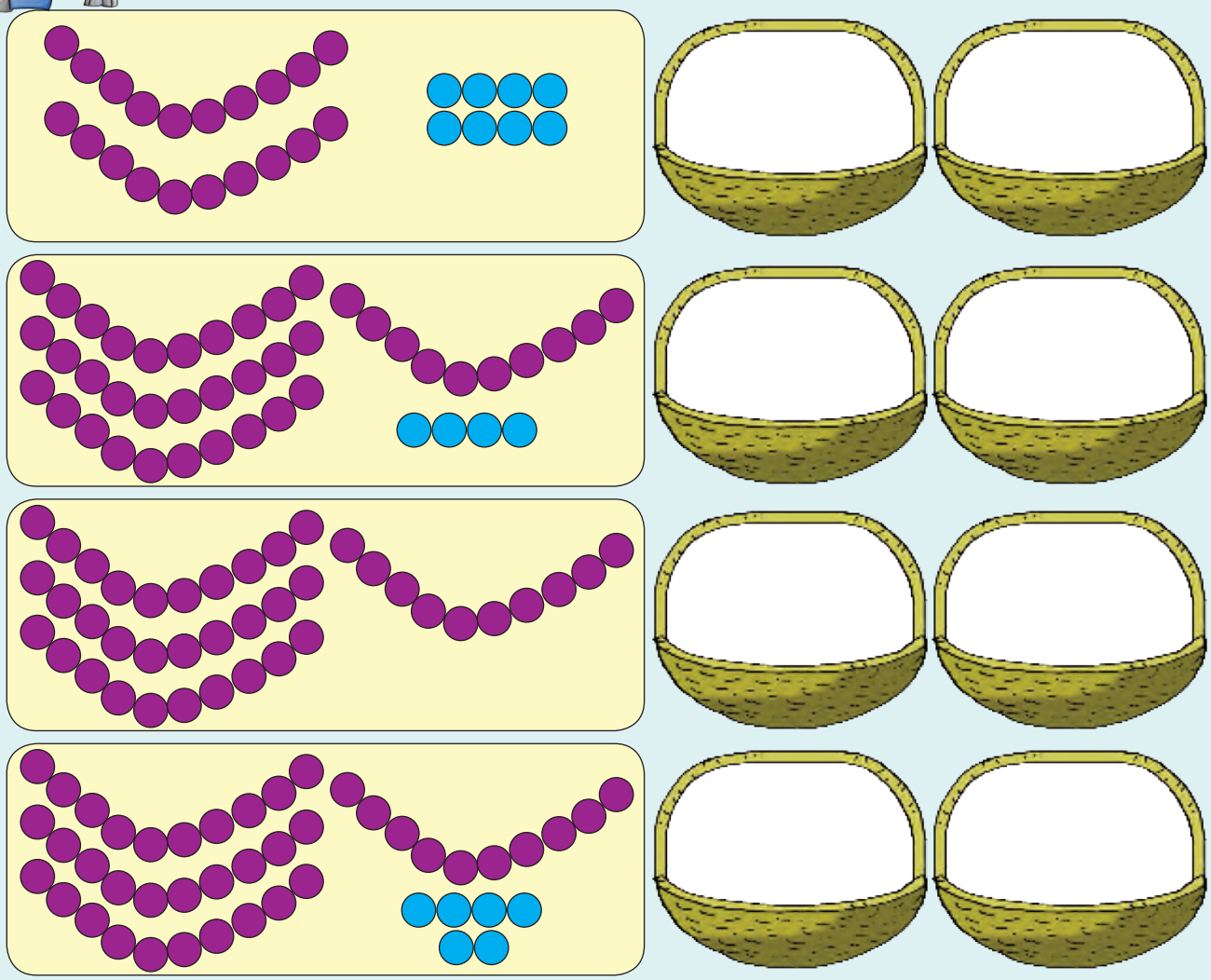



Yenza ingxenye eyodwa ibe umbala ohlukile.

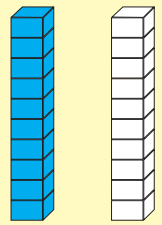

Uhhafu wamashumi amabili

10

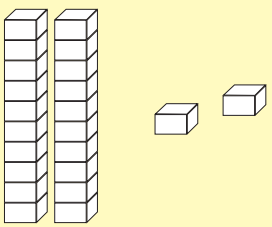

Uhhafu wamashumi amabili nambili

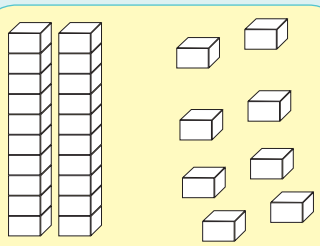

Uhhafu wamashumi amabili nesishiyagalombini

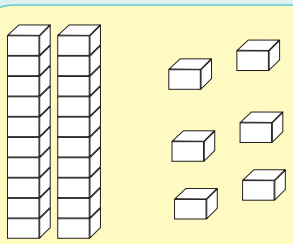

Uhhafu wamashumi amabili nesithupha



Uhhafu wamashumi amane

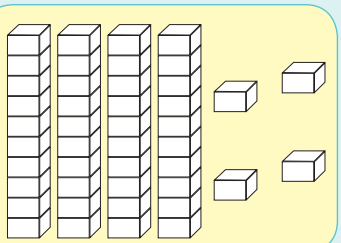

Uhhafu wamashumi amane nane

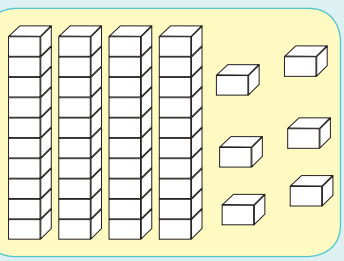

Uhhafu wamashumi amane nesithupha



Uhhafu wamashumi amahlanu

Faka umbala kuhhafu womdwebo ngamunye.

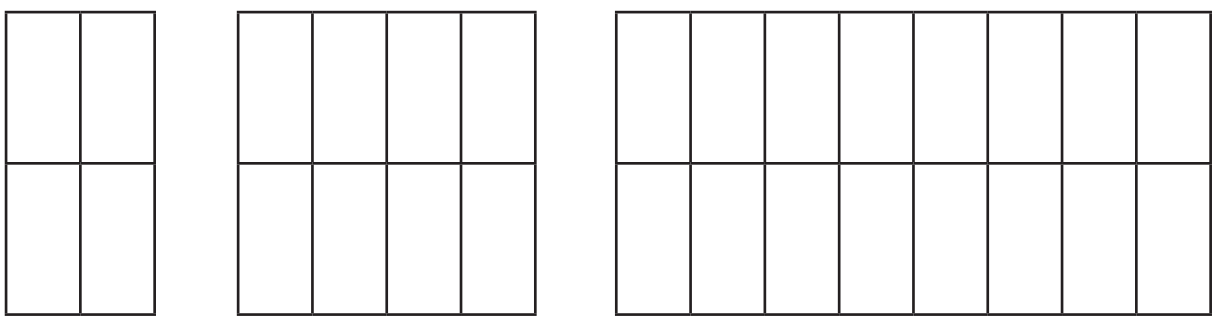

Teacher:

Sign:

Date:

11 12 13 14 15 16 17 18 19 20



Usuku: _____

Imininingwane



Hlela izithelo. Khombisa ngokwenza umdwebo. Bhala isamba sazo ebhokisini.



Ngiwahlele ngokubeka awuhlobo olufanayo ndawonye.



Okusikiwe koku-1

Incwadi yokusebenzela 10 no-40



Incwadi yokusebenzela 13

ekuseni kakhulu	emva kancane kwantambama	ntambama
ebusuku	ebusuku kakhulu	ekuseni namantambama

Okusikiwe koku-2

Incwadi yokusebenzela 22

Imigubho Ekhethekile Nenomlando

Usuku Lwamalungelo Abantu

Usuku Lokubuyisana

Usuku Lwabasebenzi

Usuku Lwentsha

Usuku Lwamasiko

Usuku lwaMkhosikazi kuZwelonke

Usuku Lwenkululeko

Izimpawu zenkolo



iBahai | iJudaic | iBuddhist | i-Islamu | ubuKrestu | Umdabu wase-Afrika | ubuHindu

Cut-out 3

Worksheets 25 and 26



R50	R50	R50	R50	R50
R10	R10	R10	R10	R10
R20	R20	R20	R20	R20
R100	R100	R100	R100	R100
R50	R50	R50	R50	R50
R10	R10	R10	R10	R10
R20	R20	R20	R20	R20
R100	R100	R100	R100	R100

Cut-out 4

Worksheet 27



Worksheet 60





Worksheet 61

