QUESTION 12

While preparing for the 2010 Soccer World Cup, a group of investors decided to build a guesthouse with single and double bedrooms to hire out to visitors. They came up with the following constraints for the guesthouse:

- There must be at least one single bedroom.
- They intend to build at least 10 bedrooms altogether, but not more than 15.
- Furthermore, the number of double bedrooms must be at least twice the number of single bedrooms.
- There should not be more than 12 double bedrooms.

Let the number of single bedrooms be x and the number of double bedrooms be y.

12.1 Write down the constraints as a system of inequalities. (6)

12.2 Represent the system of constraints on the graph paper provided on DIAGRAM SHEET 3. Indicate the feasible region by means of shading. (7)

12.3 According to these constraints, could the guesthouse have 5 single bedrooms and 8 double bedrooms? Motivate your answer. (2)

12.4 The rental for a single bedroom is R600 per night and R900 per night for a double bedroom. How many rooms of each type of bedroom should the contractors build so that the guesthouse produces the largest income per night? Use a search line to determine your answer and assume that all bedrooms in the guesthouse are fully occupied. (3)
[18]

TOTAL:150

CENTRE NUMBER:

EXAMINATION NUMBER:

DIAGRAM SHEET 1

QUESTION 5.3

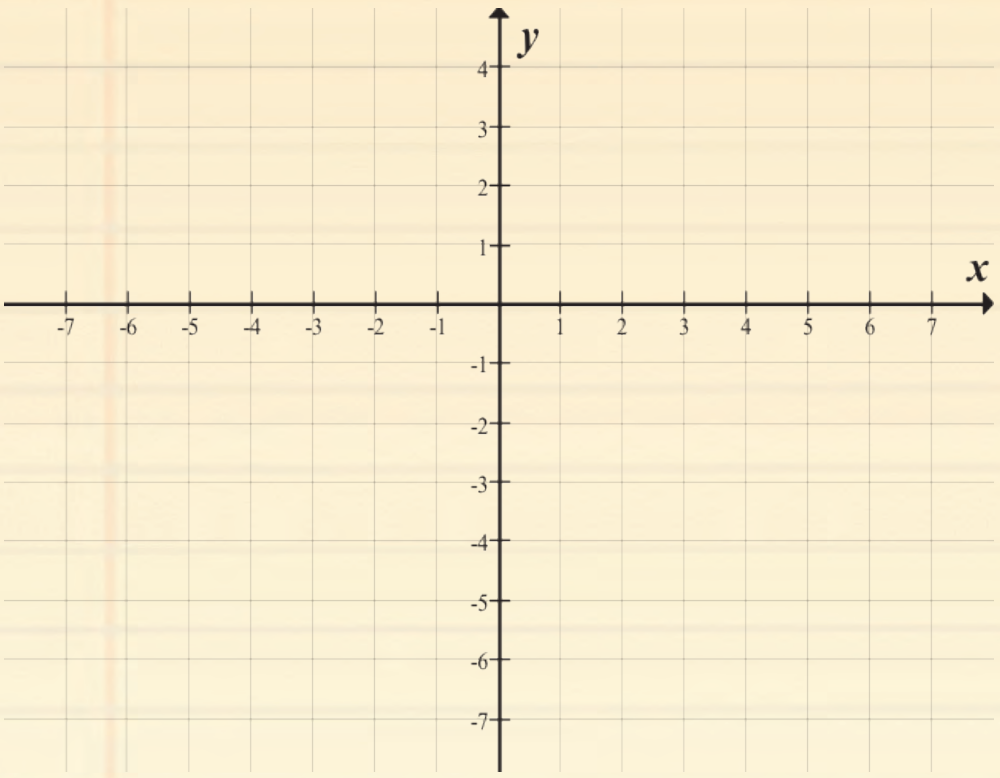

CENTRE NUMBER:

EXAMINATION NUMBER:

DIAGRAM SHEET 2

QUESTION 10.4

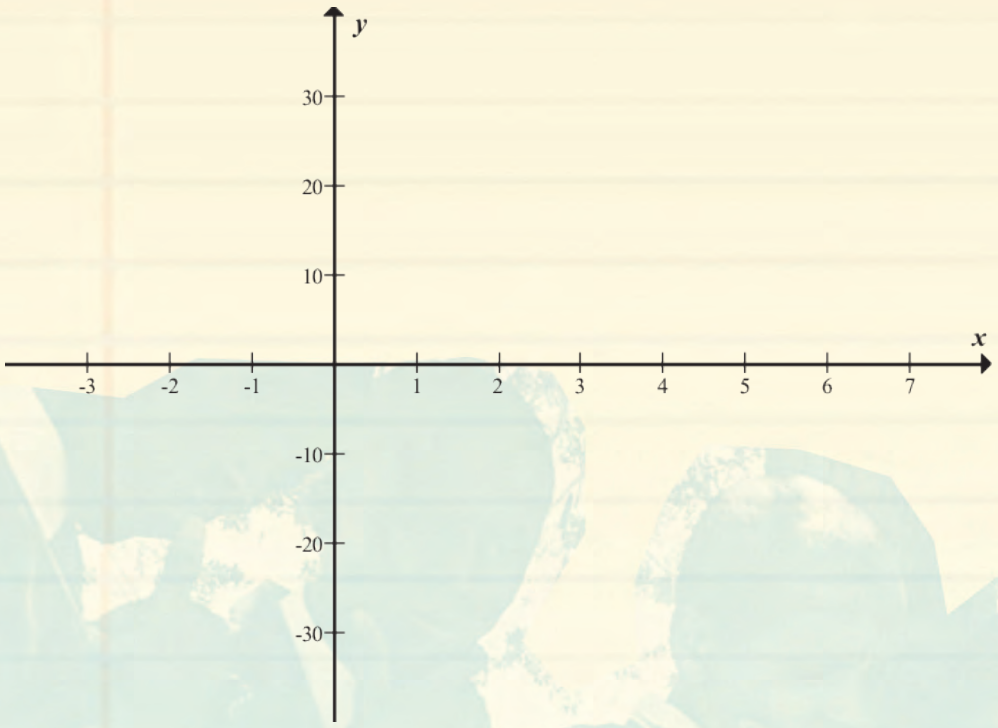

CENTRE NUMBER:

EXAMINATION NUMBER:

DIAGRAM SHEET 3

QUESTION 12.2

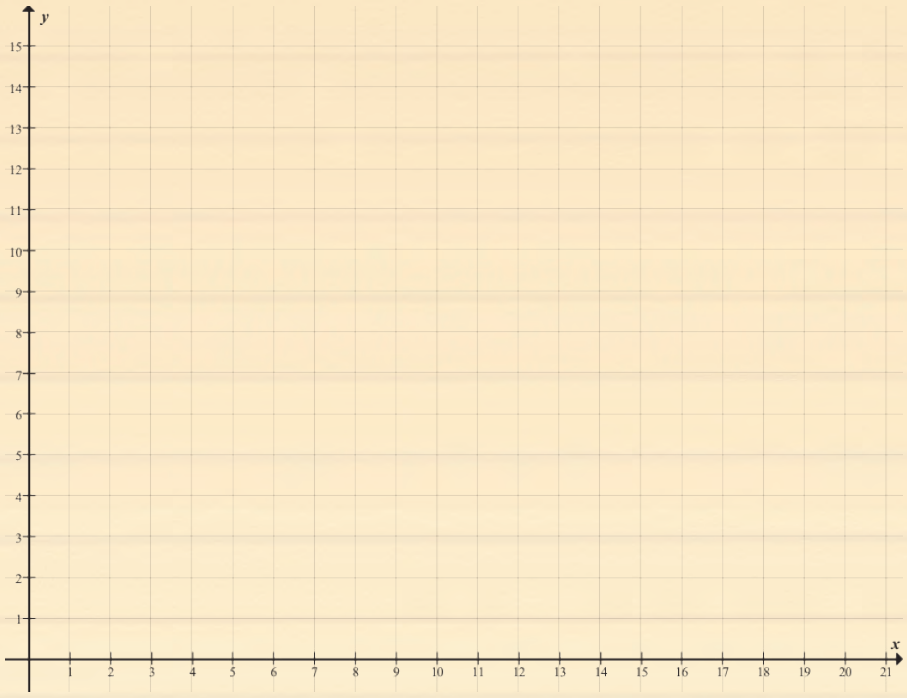

INFORMATION SHEET: MATHEMATICS

$$x = \frac{-b \pm \sqrt{b^2 - 4ac}}{2a}$$

$$A = P(1+ni) \qquad A = P(1-ni) \qquad A = P(1-i)^n \qquad A = P(1+i)^n$$

$$\sum_{i=1}^{n} 1 = n \qquad \sum_{i=1}^{n} i = \frac{n(n+1)}{2} \qquad T_n = a + (n-1)d \qquad S_n = \frac{n}{2}\left(2a + (n-1)d\right)$$

$$T_n = ar^{n-1} \qquad S_n = \frac{a\left(r^n - 1\right)}{r-1} \qquad r \neq 1 \qquad S_\infty = \frac{a}{1-r} \qquad -1 < r < 1$$

$$F = \frac{x\left[(1+i)^n - 1\right]}{i} \qquad P = \frac{x[1-(1+i)^{-n}]}{i}$$

$$f'(x) = \lim_{h \to 0} \frac{f(x+h) - f(x)}{h}$$

$$d = \sqrt{(x_2 - x_1)^2 + (y_2 - y_1)^2} \qquad \left(\frac{x_1 + x_2}{2}; \frac{y_1 + y_2}{2}\right)$$

$$y = mx + c \qquad y - y_1 = m(x - x_1) \qquad m = \frac{y_2 - y_1}{x_2 - x_1} \qquad m = \tan\theta$$

$$(x-a)^2 + (y-b)^2 = r^2$$

In ΔABC:

$$\frac{a}{\sin A} = \frac{b}{\sin B} = \frac{c}{\sin C} \qquad a^2 = b^2 + c^2 - 2bc.\cos A$$

$$area\ \Delta ABC = \frac{1}{2}ab.\sin C$$

$$\sin(\alpha + \beta) = \sin\alpha.\cos\beta + \cos\alpha.\sin\beta \qquad \sin(\alpha - \beta) = \sin\alpha.\cos\beta - \cos\alpha.\sin\beta$$

$$\cos(\alpha + \beta) = \cos\alpha.\cos\beta - \sin\alpha.\sin\beta \qquad \cos(\alpha - \beta) = \cos\alpha.\cos\beta + \sin\alpha.\sin\beta$$

$$\cos 2\alpha = \begin{cases} \cos^2\alpha - \sin^2\alpha \\ 1 - 2\sin^2\alpha \\ 2\cos^2\alpha - 1 \end{cases} \qquad \sin 2\alpha = 2\sin\alpha.\cos\alpha$$

$$(x\,;\,y) \rightarrow (x\cos\theta + y\sin\theta\,;\, y\cos\theta - x\sin\theta) \qquad (x\,;\,y) \rightarrow (x\cos\theta - y\sin\theta\,;\, y\cos\theta + x\sin\theta)$$

$$\bar{x} = \frac{\sum fx}{n} \qquad \sigma^2 = \frac{\sum_{i=1}^{n}(x_i - \bar{x})^2}{n}$$

$$P(A) = \frac{n(A)}{n(S)} \qquad P(A \text{ or } B) = P(A) + P(B) - P(A \text{ and } B)$$

$$\hat{y} = a + bx \qquad b = \frac{\sum(x - \bar{x})(y - \bar{y})}{\sum(x - \bar{x})^2}$$